This is a digital copy of a book that was preserved for generations on library shelves before it was carefully scanned by Google as part of a project to make the world's books discoverable online.

It has survived long enough for the copyright to expire and the book to enter the public domain. A public domain book is one that was never subject to copyright or whose legal copyright term has expired. Whether a book is in the public domain may vary country to country. Public domain books are our gateways to the past, representing a wealth of history, culture and knowledge that's often difficult to discover.

Marks, notations and other marginalia present in the original volume will appear in this file - a reminder of this book's long journey from the publisher to a library and finally to you.

Usage guidelines

Google is proud to partner with libraries to digitize public domain materials and make them widely accessible. Public domain books belong to the public and we are merely their custodians. Nevertheless, this work is expensive, so in order to keep providing this resource, we have taken steps to prevent abuse by commercial parties, including placing technical restrictions on automated querying.

We also ask that you:

+ *Make non-commercial use of the files* We designed Google Book Search for use by individuals, and we request that you use these files for personal, non-commercial purposes.

+ *Refrain from automated querying* Do not send automated queries of any sort to Google's system: If you are conducting research on machine translation, optical character recognition or other areas where access to a large amount of text is helpful, please contact us. We encourage the use of public domain materials for these purposes and may be able to help.

+ *Maintain attribution* The Google "watermark" you see on each file is essential for informing people about this project and helping them find additional materials through Google Book Search. Please do not remove it.

+ *Keep it legal* Whatever your use, remember that you are responsible for ensuring that what you are doing is legal. Do not assume that just because we believe a book is in the public domain for users in the United States, that the work is also in the public domain for users in other countries. Whether a book is still in copyright varies from country to country, and we can't offer guidance on whether any specific use of any specific book is allowed. Please do not assume that a book's appearance in Google Book Search means it can be used in any manner anywhere in the world. Copyright infringement liability can be quite severe.

About Google Book Search

Google's mission is to organize the world's information and to make it universally accessible and useful. Google Book Search helps readers discover the world's books while helping authors and publishers reach new audiences. You can search through the full text of this book on the web at `http://books.google.com/`

B 464093 DUPL



THE GIFT OF

Dr. James H. Maxwell

L. E. Timms 3/7/16

ENGINEERING
LIBRARY
TG
260
.J67
1910
cop. 2

The Theory and Practice of
Modern Framed Structures

Designed for the Use of Schools and for Engineers in Professional Practice

BY
The Late J. B. JOHNSON, C.E.
C. W. BRYAN, C.E.
CHIEF ENGINEER OF THE AMERICAN BRIDGE COMPANY
AND
F. E. TURNEAURE, C.E.
DEAN OF THE COLLEGE OF MECHANICS AND ENGINEERING
UNIVERSITY OF WISCONSIN

IN THREE PARTS
PART II.—Statically Indeterminate Structures and Secondary Stresses

Ninth Edition Rewritten
Total Issue Fourteen Thousand

NEW YORK
JOHN WILEY & SONS
LONDON: CHAPMAN & HALL, LIMITED
1911

Copyright, 1893, 1904
by
Estate of J. B. JOHNSON
F. E. TURNEAURE
C. W. BRYAN

Copyright, 1910, by
F. E. TURNEAURE and MRS. J. B. JOHNSON

COMPOSED AND PRINTED BY THE PUBLISHERS PRINTING CO., NEW YORK, U. S. A.

Eng. Lib.
Gift
Dr James H. Maxwell
3-1-1934

PREFACE

In the arrangement of material in the present edition of this work, Part I has included, for the most part, the analysis of such structures as are statically determinate, or which can be closely analyzed by the application of the usual methods of statics. In the last chapter of Part I there was also given a brief treatment of the calculation of deflections of ordinary trusses, and a general explanation of the method of determining stresses in redundant members based upon deflection formulas.

The present volume, Part II, treats, in the main, of structures which are statically indeterminate, but it also includes the analysis of cantilever bridges, which is generally a statically determinate problem. However, on account of other elements of analysis, such as the use of influence lines, and the relation of the cantilever bridge to the continuous girder, it seemed more convenient to include this subject in Part II than to place it in Part I. Furthermore, the cantilever without suspended span becomes a statically indeterminate structure.

As compared with the corresponding chapters of the former edition, the present work has been greatly extended in scope and entirely rewritten. The analysis of the different types of structures considered has been made much more complete, and two chapters have been added covering various problems in statically indeterminate structures and the subject of secondary stresses. The general method of influence lines has been freely used in many of the problems, both as an aid to clear treatment and for purposes of convenient calculation. Other graphical methods have also been used wherever they seemed to be advantageous.

Chapter I gives a brief general treatment of the continuous girder for both constant and variable moment of inertia. This is followed by Chapter II on swing bridges, where both approximate and exact methods are fully explained. In Chapter III the cantilever bridge is

briefly discussed, and in Chapter IV the various types of arches are analyzed by the usual methods. Chapter V contains a relatively extended treatment of the suspension bridge. The space given to this subject is, perhaps, hardly warranted, inasmuch as such structures are of infrequent occurrence, but the relative inaccessibility of material on this subject, that is adequate for the treatment of important structures, led the author to develop this chapter to a considerable extent. The so-called "exact theory" (Art. 222) is based upon the work of Melan, "Eiserne Bogenbrücken und Haengebrücken." This theory was fully developed by Mr. L. S. Moisseiff of the Department of Bridges of the City of New York, and used in the calculations of the Manhattan suspension bridge, and later by the author, with various modifications, in the recalculations of this structure, for Mr. Ralph Modjeska and given in his report to the City of New York, 1909. (See *Engineering News*, Vol. 62, page 401, *Engineering Record*, Vol. 60, page 372.) In this treatise this theory has been further extended and a study made of the errors involved. The detailed development of the methods employed and the preparation of the same for publication have been almost entirely the work of Professor W. S. Kinne, to whom the author is also indebted for assistance in proof-reading and in many other valuable details.

Chapter VI includes several general problems of importance pertaining to statically indeterminate structures. These are grouped under five divisions, namely, multiple intersection trusses, lateral truss systems, quadrangular or open frames of four sides, trussed beams, and beams on multiple elastic supports. Under quadrangular frames are discussed several problems pertaining to portal bracing, viaduct bents, and towers. The last-named division includes the common problem of determining the maximum load on a single transverse element of a railroad bridge floor. Some of the problems included in this chapter are of relatively small importance and are introduced more to illustrate methods of analysis than for their direct practical value.

In Chapter VII the author has endeavored to present the analysis of secondary stresses in such detail as to enable it to be readily followed and adapted to any ordinary problem. Especial care has been taken to systematize the calculations so as to reduce the labor involved to a minimum, and it is believed that a little familiarity with the method

will enable any good computor to completely analyze an ordinary single intersection truss for secondary stresses in less than two working days. The fundamental theory of the subject was developed many years ago by German writers, and the present work contains nothing new in that direction. In the lengthy calculations involved, however, the scheme of arrangement is very important and, in this respect, it is thought that the treatment herein given presents features of value which will aid in bringing this very important subject to a better working basis than has hitherto been the case. In addition to a full explanation of the methods of analysis employed, several illustrative examples are given, and also general calculations, which indicate, to a certain extent, the relative secondary stresses in various types of trusses. In addition to the secondary stresses in main trusses due to rigid joints, several interesting problems of more or less practical importance are discussed, and at the end of the chapter the subject of impact stresses is briefly treated on the basis of the experimental work done by the Impact Committee of the American Railway Engineering and Maintenance of Way Association.

The thanks of the author are due to many engineering friends for suggestions received with reference to practical problems of analysis arising in their practice. It is hoped that the present work will be of assistance to engineers as well as to students in acquiring a working knowledge of the methods of analysis applicable to statically indeterminate structures.

F. E. TURNEAURE.

MADISON, Dec., 1910.

TABLE OF CONTENTS

CHAPTER I

CONTINUOUS GIRDERS

SECTION I.—DEFLECTION OF STRAIGHT BEAMS

ART.		PAGE
1.	THE ELASTIC CURVE,	1
2.	ANGULAR CHANGE AT ANY POINT,	2
3.	DEFLECTION AT ANY POINT,	2
4.	*Examples*,	3
5.	GRAPHICAL CALCULATION OF ANGULAR CHANGE AND DEFLECTION,	5
6.	*Examples*,	7
7.	TABLE OF MOMENTS, STRESSES, AND DEFLECTIONS,	9
8.	DEFLECTION DUE TO SHEAR,	9

SECTION II.—CONTINUOUS GIRDERS

9.	DEFINITION,	15
10.	SHEAR AND BENDING MOMENT IN ANY SPAN,	15
11.	THEOREM OF THREE MOMENTS,	16
12.	*Concentrated loads*,	17
13.	*Uniform loads*,	18
14.	EFFECT OF MOVEMENT OF SUPPORTS,	18
15.	MOMENTS AT SUPPORTS,	19
16.	GENERAL FORMULAS FOR MOMENTS,	20
17.	GENERAL FORMULAS FOR REACTIONS,	23
18.	CONTINUOUS GIRDER OF TWO EQUAL SPANS. *Uniform load on both spans*,	24
19.	*Uniform load on one span*,	25
20.	*Concentrated load on one span*,	25
21.	*Influence lines for moments and shears*,	27
22.	*Maximum moments and shears*,	29
23.	CONTINUOUS GIRDER OF TWO UNEQUAL SPANS,	30
24.	CONTINUOUS GIRDER OF THREE SPANS. *Uniform load on all spans*,	30
25.	*Concentrated load on one span*,	31
26.	*Influence lines for moments and shears*,	33
27.	MAXIMUM MOMENTS AND SHEARS IN A CONTINUOUS GIRDER OF THREE EQUAL SPANS,	34
28.	CONTINUOUS GIRDERS OF SEVERAL SPANS,	34
29.	*Influence lines*,	35
30.	*Maximum moments for uniform load*,	36

ART. PAGE
31. CONTINUOUS GIRDERS WITH VARIABLE MOMENT OF INERTIA, ... 37
32. *Formulas for reactions*, ... 37
33. *Example*, ... 39
34. THE ANALYSIS OF CONTINUOUS TRUSSES, ... 40
35. THE MOMENT OF INERTIA OF A TRUSS, ... 41
36. USE OF CONTINUOUS GIRDERS, ... 41

CHAPTER II

SWING BRIDGES

SECTION I.—GENERAL CONSIDERATIONS

37. GENERAL ARRANGEMENT, ... 43
38. ARRANGEMENTS AT CENTRE SUPPORTS, ... 43
39. ARRANGEMENTS OF END SUPPORTS, ... 45
40. APPLICATION OF CONTINUOUS GIRDER FORMULAS, ... 45
41. LOADS, ... 45

SECTION II.—THE CENTRE-BEARING SWING BRIDGE

42. FORMULAS FOR REACTIONS, ... 46
43. END CONDITIONS ASSUMED, ... 48
44. PLATE-GIRDER BRIDGE OF TWO EQUAL SPANS, ... 50
45. *Case I. Dead load; bridge swinging*, ... 50
46. *Case II. Dead load; bridge closed; ends raised*, ... 50
47. *Case III. Live load; positive moments and shears*, ... 52
48. *Case IV. Live load; negative moments and shears*, ... 54
49. *Maximum moments and shears*, ... 55
50. *Impact allowance*, ... 56
51. *Reversal of stress*, ... 57
52. *Effect of "unbroken loads,"* 57
53. *Ends latched down*, ... 58
54. CENTRE-BEARING TRUSS BRIDGE OF TWO EQUAL SPANS, ... 58
55. *Case I. Dead load; bridge swinging*, ... 58
56. *Case II. Dead load; ends raised*, ... 59
57. *Case III. Live load; positive moments and shears*, ... 60
58. *Case IV. Live load; negative moments and shears*, ... 61
59. *Case V. Live load; bridge acting as single span*, ... 62
60. *Maximum and minimum shears*, ... 62
61. USE OF INFLUENCE LINES, ... 64
62. USE OF EQUIVALENT UNIFORM LOADS, ... 65
63. TRUE REACTIONS CALCULATED FROM DEFLECTIONS, ... 66
64. *Example*, ... 68
65. *Deflection under dead load and amount of up-lift required*, . . . 71
66. EFFECT OF TEMPERATURE VARIATIONS, ... 72
67. COUNTERBALANCED SWING BRIDGES, ... 72

SECTION III.—THE RIM-BEARING SWING BRIDGE

ART. PAGE
68. TRUSS CONTINUOUS OVER FOUR SUPPORTS, ... 73
69. *Calculation by continuous-girder formulas*, ... 73
70. *Calculation by method of redundant members*, ... 75
71. *Comparison of results*, ... 78
72. *Stresses in centre diagonals*, ... 79
73. TRUSS CONTINUOUS OVER THREE SUPPORTS, ... 79
74. TRUSS PARTIALLY CONTINUOUS OVER FOUR SUPPORTS, ... 80
75. *Reactions for a beam partially continuous over four supports*, . . 80
76. *Example of truss bridge*, ... 82
77. *True reactions for truss partially continuous over four supports*, . . 86
78. RIM-BEARING TURN-TABLE; FOUR SUPPORTS, ... 87
79. LIFT SWING BRIDGES, ... 88
80. DOUBLE SWING BRIDGES, ... 89
81. STRESSES IN LATERAL TRUSSES, ... 90

CHAPTER III

CANTILEVER BRIDGES

82. GENERAL ARRANGEMENT OF SPANS, ... 92
83. ADVANTAGES OF THE CANTILEVER BRIDGE, ... 92
84. ANALYSIS, ... 96
85. *Equivalent uniform loads*, ... 99
86. DIVIDED SUPPORTS AT THE PIERS, ... 99
87. DEFLECTION OF CANTILEVER BRIDGES, ... 99
88. CANTILEVER BRIDGE WITHOUT SUSPENDED SPAN, ... 100
89. WIND STRESSES, ... 101

CHAPTER IV

ARCH BRIDGES

SECTION I.—GENERAL CONSIDERATIONS

90. DEFINITION, ... 102
91. KINDS OF ARCHES, ... 102
92. *Masonry arches*, ... 103
93. LOADS AND REACTIONS, ... 104
94. INTERNAL STRESSES, ... 106
95. *The arch rib*, ... 106
96. *The braced arch*, ... 109
97. ADVANTAGES OF THE ARCH BRIDGE, ... 110
98. DEFLECTION OF CURVED BEAMS, ... 112
99. *Angular change*, ... 113
100. *Components of deflection*, ... 114

ART. PAGE

101. *Effect of direct stress on deflection*, ... 115
102. *Effect of temperature changes*, ... 116
103. *Combined results*, ... 117
104. APPLICATION OF DEFLECTION FORMULAS TO ARCHES, ... 117
105. *Application to trussed arches*, ... 119

SECTION II.—ARCHES OF THREE HINGES

106. REACTIONS AND STRESSES FOR DEAD LOAD, ... 119
107. REACTIONS FOR A SINGLE LOAD, ... 120
108. USE OF REACTION LINES, ... 121
109. INFLUENCE LINES, ... 122
110. *Influence lines for H*, ... 122
111. *Influence lines for moments*, ... 122
112. *Criterion for maximum moments*, ... 124
113. *Influence lines for shears*, ... 124
114. *Influence lines for thrust*, ... 126
115. EQUIVALENT UNIFORM LOADS, ... 126
116. DEFLECTION, ... 126
117. *Deflection due to temperature changes*, ... 130
118. STRESSES IN LATERAL SYSTEMS, ... 131

SECTION III.—ARCHES OF TWO HINGES

119. GENERAL FORMULAS FOR REACTIONS FOR ARCH RIBS, ... 134
120. *Arch on yielding support*, ... 137
121. *Relative effect of deformation due to thrust*, ... 138
122. GENERAL METHOD OF APPLICATION, ... 139
123. PARABOLIC ARCH WITH VARIABLE MOMENT OF INERTIA, ... 139
124. *Value of H for a single load*, ... 140
125. *Value of H for temperature change*, ... 141
126. *Value of H for end displacement*, ... 141
127. *The reaction locus*, ... 141
128. CIRCULAR ARCH OF CONSTANT SECTION. *Value of H for a single load*, . . . 142
129. *Value of H for temperature change*, ... 143
130. *Value of H for end displacement*, ... 144
131. *The reaction locus*, ... 144
132. CALCULATION OF *H* FOR ARCH RIBS, ... 144
133. THE BRACED ARCH. *General formula for H*, ... 146
134. *Use of a tie-rod*, ... 147
135. *Value of H for a single load*, ... 148
136. *Graphical method of calculating H*, ... 149
137. *The reaction locus*, ... 150
138. *Value of H for temperature change*, ... 150
139. STRESS CALCULATION. *Dead load stresses*, ... 150
140. *Live load stress. The reaction locus*, ... 151
141. *Influence lines for moments*, ... 151
142. *Influence lines for shear*, ... 153

ART. PAGE

143. *Influence lines for thrust*, ... 153
144. *Position of load for maximum stress*, ... 154
145. EXAMPLES, ... 155
146. *Approximate analysis*, ... 155
147. *Exact calculation*, ... 157
148. *Temperature stresses*, ... 159
149. *Shearing stresses*, ... 159
150. *Values of H for circular arch*, ... 160
151. *Analysis of a braced arch*, ... 160
152. DEFLECTION OF TWO-HINGED ARCHES, ... 165
153. WIND STRESSES, ... 166

SECTION IV.—ARCHES WITHOUT HINGES

154. GENERAL FORMULAS FOR ARCHED RIBS, ... 169
155. TEMPERATURE STRESSES, ... 172
156. STRESSES DUE TO SHORTENING OF ARCH, ... 173
157. PARABOLIC ARCH WITH VARIABLE MOMENT OF INERTIA, ... 173
158. *Stresses due to a single load*, ... 173
159. *Stresses due to changes in temperature*, ... 175
160. *Stresses due to shortening of arch*, ... 176
161. *Reaction lines*, ... 176
162. *Position of loads for maximum stress*, ... 177
163. *Influence lines*, ... 179
164. DEFLECTION OF AN ARCH RIB, ... 179
165. THE BRACED ARCH, ... 179
166. *Graphical method of analysis*, ... 183
167. *Temperature stresses*, ... 184
168. *Wind stresses*, ... 184
169. *Relative advantages of the arch with fixed ends*, ... 185

CHAPTER V

SUSPENSION BRIDGES

170. INTRODUCTION, ... 186

SECTION I.—THE CABLE

171. FORM OF CABLE. *Any loading*, ... 186
172. *Load uniform along the horizontal*, ... 187
173. *Load uniform along the cable*, ... 188
174. *Side spans*, ... 191
175. *Unsymmetrical spans*, ... 191
176. LENGTH OF CABLE. *Main Span, Parabolic Cable*, ... 192
177. *Main span. Catenary cable*, ... 193
178. *Side spans*, ... 194
179. STRESSES IN THE CABLE FOR UNIFORM LOADS. *Parabolic cable*, . . . 195
180. *Catenary cable*, ... 197
181. DEFORMATION OF CABLE, ... 198

SECTION II.—UNSTIFFENED SUSPENSION BRIDGES

ART. PAGE
182. INTRODUCTION, ... 200
183. STRESSES IN THE CABLE, ... 200
184. DEFORMATION OF CABLE UNDER PARTIAL LOADING, ... 201

SECTION III.—STIFFENED SUSPENSION BRIDGES

185. INTRODUCTION, ... 209
186. METHOD OF PROCEDURE, ... 211

A. APPROXIMATE METHODS OF CALCULATION

187. GENERAL EQUATION FOR H AND FOR MOMENTS AND SHEARS, ... 212

(*a*) *Structure over a single opening. Truss hinged at ends*

188. VALUE OF H FOR VARIOUS CASES, ... 213
189. EFFECT OF TEMPERATURE CHANGES ON H, ... 219
190. MOMENTS AND SHEARS, ... 220
191. INFLUENCE LINES FOR MOMENTS, ... 221
192. MOMENTS FROM INFLUENCE LINES, ... 221
193. EFFECT OF TEMPERATURE ON MOMENTS, ... 223
194. INFLUENCE LINES FOR SHEARS, ... 224
195. SHEARS FROM INFLUENCE LINES, ... 225
196. EFFECT OF TEMPERATURE ON SHEARS, ... 225
197. DEFLECTION OF THE STIFFENING TRUSS, ... 225
198. INFLUENCE LINES FOR DEFLECTIONS, ... 228
199. EFFECT OF TEMPERATURE ON DEFLECTION, ... 229

(*b*) *Structure over three openings. Side spans suspended. Trusses hinged*

200. VALUE OF H, ... 230
201. MOMENTS AND SHEARS, ... 235
202. INFLUENCE LINES, ... 236
203. DEFLECTION OF STIFFENING TRUSS, ... 237
204. DEFLECTION OF TOWER OR MOVEMENT OF SADDLE, ... 237
205. EXAMPLE, ... 239

(*c*) *Structure over three openings. Side spans free. Straight back stays*

206. VALUE OF H, ... 249
207. MOMENTS AND SHEARS, ... 250
208. EXAMPLE, ... 250

(*d*) *Structure over three openings. Trusses continuous over towers*

209. VALUE OF H, ... 252
210. MOMENTS AND SHEARS, ... 256
211. INFLUENCE LINES, ... 257
212. EXAMPLE, ... 257
213. STRAIGHT BACK STAYS, ... 259

(e) *Structure over three openings. Trusses continuous over towers. Centre hinge*

ART. PAGE

214. VALUE OF H, ... 260
215. MOMENTS AND SHEARS, ... 264
216. EXAMPLE, ... 264
217. STRAIGHT BACK STAYS, ... 264

(f) *Structure with stiffening truss hinged at ends and centre*

218. VALUE OF H, ... 265
219. MOMENTS AND SHEARS, ... 268
220. EXAMPLE, ... 274

(g) *Comparison of various types of structures*

221. COMPARISON OF RESULTS, ... 274

B. EXACT METHODS OF CALCULATION

(a) *Structure with trusses hinged or continuous at towers*

222. METHOD OF PROCEDURE, ... 276
223. DERIVATION OF FORMULAS FOR DEFLECTION, MOMENT, AND SHEAR, . . . 278
224. CONSTANTS OF INTEGRATION, ... 281
225. FORMULA FOR H, ... 283
226. CONDITIONS OF LOADING FOR MAXIMUM MOMENTS AND SHEARS, . . . 289
227. EXAMPLE, ... 290
228. EFFECT OF EXTENSION OF HANGERS, ... 299
229. EFFECT OF VARIABLE MOMENT OF INERTIA, ... 302
230. EFFECT OF VARIABLE HANGER PULL ON VALUE OF H, ... 308

(b) *Structure with truss hinged at centre*

231. DERIVATION OF FORMULAS FOR MOMENTS AND SHEARS, ... 313
232. EFFECT OF TEMPERATURE ON MOMENTS, ... 315
233. EXAMPLE, ... 316

C. ERECTION ADJUSTMENTS

234. HEIGHT OF CABLE BEFORE ADDITION OF DEAD LOAD, ... 319
235. CLOSURE OF STIFFENING TRUSSES, ... 320

SECTION IV.—STRESSES IN LATERAL TRUSSES, TOWERS, AND FLOORBEAMS

236. WIND STRESSES IN STRUCTURES WITH HORIZONTAL STIFFENING TRUSSES, . . 321
237. WIND STRESSES IN OTHER TYPES OF SUSPENSION BRIDGES, ... 323
238. FLOORBEAM STRESSES, ... 323
239. TOWER STRESSES, ... 325

SECTION V.—STRUCTURES WITH STIFFENED SUSPENSION FRAMES

240. SUSPENSION BRIDGES WITH THREE HINGES, ... 329
241. SUSPENSION BRIDGES WITH TWO HINGES, ... 330
242. SUSPENSION BRIDGES WITH STIFFENED CABLES, CONTINUOUS FROM ANCHORAGE TO ANCHORAGE, ... 331

CHAPTER VI

MISCELLANEOUS PROBLEMS IN STATICALLY INDETERMINATE STRUCTURES

SECTION I.—MULTIPLE INTERSECTION TRUSSES

ART. PAGE

243. GENERAL FORMULAS, ... 332
244. *Equations derived from the principle of least work*, ... 335
245. FORMS OF TRUSSES AND METHODS OF ANALYSIS, ... 336
246. THE DOUBLE TRIANGULAR TRUSS WITH VERTICAL END POSTS, . . . 336
247. *Odd number of panels*, ... 337
248. THE DOUBLE TRIANGULAR TRUSS WITH INCLINED END POSTS, . . . 342
249. THE WHIPPLE TRUSS, ... 345
250. OTHER MULTIPLE SYSTEMS, ... 346
251. GENERAL CONCLUSIONS REGARDING MULTIPLE SYSTEM, ... 348
252. THE DOUBLE TRIANGULAR TRUSS WITH VERTICALS, ... 349
253. *General equations*, ... 350
254. *Values of* $\Sigma \frac{u^2 l}{A}$ 351
255. *Values of* $\Sigma \frac{S' u l}{A}$ 352
256. *Solution of equations*, ... 355
257. *Stresses and influence lines for diagonals*, ... 356
258. *Influence lines for the intermediate verticals*, ... 357
259. *General conclusions*, ... 359
260. GENERAL CASE OF DOUBLE DIAGONALS IN A PRATT SYSTEM, . . . 360
261. THE COUNTERS OF A BALTIMORE OR A PETIT TRUSS, ... 361

SECTION II.—LATERAL TRUSS SYSTEMS

262. FORMS OF LATERAL TRUSSES AND GENERAL METHODS OF ANALYSIS, . . 364
263. STRESSES DUE TO DISTORTIONS OF MAIN MEMBERS, ... 365
264. LATERAL STRESSES IN CURVED-CHORD TRUSSES, ... 369
265. LATERAL BRACING NECESSARY FOR RIGIDITY OF TRUSSES, ... 369
266. REDUNDANT REACTIONS, ... 371
267. STRESSES DUE TO UNEQUAL SETTLEMENT OF SUPPORTS, ... 372
268. STRESSES IN LATERAL TRUSSES DUE TO VERTICAL LOADS, ... 377
269. TRANSVERSE BRACING, ... 378
270. *Stresses due to lateral forces*, ... 379
271. *Stresses due to unequally loaded main trusses*, ... 380
272. PROPORTIONS OF LATERAL BRACING FOR MAXIMUM RIGIDITY, . . . 382

SECTION III.—THE QUADRANGULAR OR PORTAL FRAME

273. THE QUADRANGULAR FRAME, ... 383
274. GENERAL SOLUTION, ... 384
275. SYMMETRICAL FRAMES, ... 286
276. QUADRANGULAR FRAMES WITH BRACKETS, ... 388
277. FRAME WITH POSTS FIXED AT ONE END, ... 389

ART. PAGE
278. FRAME WITH POSTS HINGED AT ONE END, ... 390
279. TEMPERATURE STRESSES, ... 392
280. EFFECT OF LATERAL FORCES, ... 394
281. PARTIAL TRUSSED PORTAL FRAMES, ... 396
282. FRAMES WITH INCLINED END POSTS, ... 398
283. PORTAL FRAMES OF MULTIPLE STORIES, ... 400
284. PORTAL-BRACED TOWERS WITH INCLINED POSTS, ... 403
285. DEFLECTION OF QUADRANGULAR FRAMES, ... 406

SECTION IV.—TRUSSED BEAMS

286. THE KING-POST TRUSS, ... 408
287. THE QUEEN-POST TRUSS WITHOUT DIAGONALS, ... 410
288. TRUSS OF SEVERAL PANELS WITH DIAGONALS OMITTED IN ONE PANEL, . . 412

SECTION V.—BEAMS ON MULTIPLE ELASTIC SUPPORTS

289. THE GENERAL PROBLEM, ... 412
290. GENERAL METHOD OF SOLUTION, ... 413
291. DEFLECTION OF THE TRANSVERSE BEAM, ... 414
292. THE LONGITUDINAL BEAM, ... 415
293. *Deflections due to load P*, ... 416
294. *Deflections due to* R_1, ... 417
295. *Deflections due to* R_2, ... 417
296. *Deflections due to* R_3, ... 418
297. *Deflections due to* R_4, ... 418
298. *Resulting equations*, ... 419
299. *Equations for seven and five supports*, ... 419
300. DIAGRAM OF VALUES OF REACTIONS, ... 419

CHAPTER VII

SECONDARY STRESSES

301. PRIMARY AND SECONDARY STRESSES, ... 423
302. SECONDARY STRESSES DUE TO RIGIDITY OF JOINT. *Nature of the Problem*, . 423
303. CALCULATION OF CHANGES OF ANGLE IN ANY TRIANGLE, ... 425
304. THE DEFLECTION ANGLES OF A BEAM, ... 427
305. NOTATION AND CONVENTIONAL SIGNS, ... 428
306. VALUES OF DEFLECTION ANGLES, ... 429
307. SELECTION OF REFERENCE DEFLECTION ANGLES, ... 430
308. MOMENTS AT ANY JOINT IN TERMS OF DEFLECTION ANGLES, ... 431
309. *Fibre stresses in terms of deflection angles*, ... 432
310. ARRANGEMENT OF CALCULATIONS, ... 432
311. *Calculation of values of angular changes*, ... 433
312. *Calculation of summation of angular changes*, ... 436
313. *Formulation of equations*, ... 436
314. *Solution of equations*, ... 437
315. *Calculation of values of deflection angles and bending moments*, . 439
316. *General remarks*, ... 439

ART.		PAGE
317.	SECONDARY STRESSES IN A PRATT TRUSS,	440
318.	*Calculation of changes of angles*	443
319.	*Calculation of* $\Sigma \delta \angle$ *and* $K \Sigma \delta \angle$ *at the several joints,*	443
320.	*Formulation of equations,*	445
321.	*Solution of equations,*	445
322.	*Calculation of deflection angles and fibre stresses,*	449
323.	*Total secondary stresses and relation to primary stresses,*	453
324.	GENERAL REMARKS ON METHOD OF CALCULATION,	455
325.	APPROXIMATE METHODS OF CALCULATION FOR A LIMITED NUMBER OF JOINTS,	457
326.	EFFECT OF COLLISION STRUTS,	458
327.	EFFECT OF ECCENTRIC JOINTS,	462
328.	EFFECT OF PIN CONNECTIONS,	464
329.	*Top chord of pin-connected truss,*	466
330.	EFFECT OF BENDING MOMENTS DUE TO TRANSVERSE LOADS,	468
331.	SECONDARY STRESSES IN TOP CHORD DUE TO WEIGHT OF MEMBER,	470
332.	SECONDARY STRESSES DUE TO FIXED SUPPORTS,	472
333.	CALCULATION OF CHANGES OF ANGLE IN FIGURES OF FOUR OR MORE SIDES,	476
334.	*The Baltimore truss,*	476
335.	*The double triangular truss,*	477
336.	RELATIVE AMOUNTS OF SECONDARY STRESSES IN TRUSSES OF DIFFERENT TYPES	478
337.	*General method of analysis,*	479
338.	*The Pratt truss system,*	479
339.	*The Warren truss system,*	485
340.	*The double intersection triangular truss,*	487
341.	*The double triangular truss with verticals,*	491
342.	*The Baltimore truss,*	492
343.	*The double triangular truss with sub-verticals,*	494
344.	SECONDARY STRESSES DUE TO THE ACTION OF LATERAL TRUSSES,	495
345.	*The single Warren system,*	496
346.	*The double Warren system,*	497
347.	*Pratt truss with double diagonals,*	497
348.	EFFECT OF LACING ON SECONDARY STRESSES IN COMPRESSION MEMBERS,	497
349.	EFFECT OF SECONDARY UPON PRIMARY STRESSES,	498
350.	SECONDARY STRESSES IN TRANSVERSE FRAMES,	501
351.	SECONDARY STRESSES DUE TO ACTION OF STRINGERS,	503
352.	DEFLECTION OF MEMBERS DUE TO SECONDARY STRESSES,	506
353.	EXACT METHOD OF CALCULATING SECONDARY STRESSES,	507
354.	STRESSES IN RIVETED EXPANSION SUSPENDERS,	514
355.	BENDING MOMENTS IN MEMBERS SUBJECTED TO TRANSVERSE LOADS AND DIRECT STRESSES,	515
356.	*Approximate general formulas,*	520
357.	IMPACT STRESSES. *Static and dynamic stresses,*	522
358.	*Causes of impact,*	523
359.	*Effect of speed of application of load,*	524
360.	*Effect of other causes of impact,*	525
361.	*General results of tests for all spans,*	528
362.	*Impact percentages for various truss members,*	528
363.	*Summary of results of tests,*	528

THEORY AND PRACTICE

IN THE DESIGNING OF

MODERN FRAMED STRUCTURES

PART II

STATICALLY INDETERMINATE STRUCTURES SECONDARY STRESSES

CHAPTER I

CONTINUOUS GIRDERS

SECTION I.—DEFLECTION OF STRAIGHT BEAMS

1. **The Elastic Curve.**—Let $A\,B$, Fig 1, be any portion of a horizontal beam subjected to certain bending moments and shears due to the action of vertical forces. The curvature due to bending is only slight, and it is assumed that the length of any part may be taken equal to its horizontal projection. Assume the following notation:

M = bending moment at any section, assumed as positive when causing compression in the upper fibres;

x, y = coordinates of any point N referred to an origin at O, the axis of X being tangent to the beam at A (y is also the deflection of point N from its original position);

φ = inclination of tangent at N, = angular change in the beam at N due to stress;

$d\,\varphi$ = angular change over the length $d\,x$;

I = moment of inertia at any section;

E = modulus of elasticity, assumed as constant;

ρ = radius of curvature at N.

It is shown in treatises on mechanics that, neglecting the distortion due to shear, the differential equation of the elastic curve is

$$\frac{d^2y}{dx^2} = \frac{M}{EI}. \quad . \quad . \quad . \quad . \quad . \quad . \quad . \quad . \quad (1)$$

The radius of curvature is given by the formula

$$\frac{1}{\rho} = \frac{d^2y}{dx^2} = \frac{M}{EI}. \quad . \quad . \quad . \quad . \quad . \quad . \quad . \quad (2)$$

2. Angular Change at Any Point.—Integrating eq. (1) between A and any point N we obtain the value of $\frac{dy}{dx}$ or φ for this point. This

See Page 113

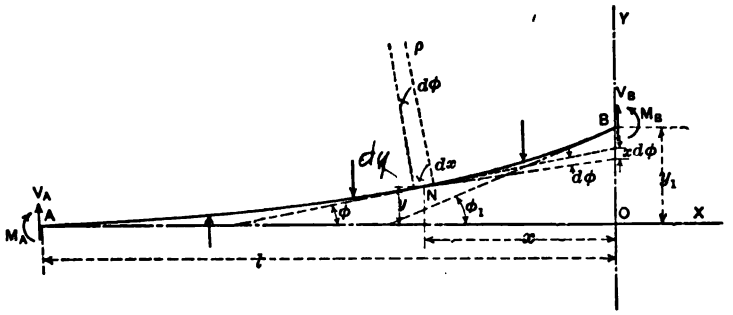

FIG. 1.

angular change, referred to the tangent at A, is therefore expressed by the general equation,

$$\varphi = \frac{dy}{dx} = \int \frac{M\,dx}{EI}, \quad . \quad . \quad . \quad . \quad . \quad . \quad . \quad (3)$$

and for point B

$$\varphi_1 = \int_A^B \frac{M\,dx}{EI}. \quad . \quad . \quad . \quad . \quad . \quad . \quad . \quad (3a)$$

3. Deflection of Any Point.—The general value of $\frac{dy}{dx}$ being found from (3) the deflection y is obtained by a second integration between the limits A and N, or, in general,

$$y = \int dy = \iint \frac{M\,dx^2}{EI}. \quad . \quad . \quad . \quad . \quad . \quad . \quad (4)$$

The deflection may often be more conveniently found by a single integration as follows: Consider the deflection at point B with respect to the tangent $A\,O$. The angular change of an element $d\,x$ at any point N is $d\,\varphi = \frac{M\,d\,x}{E\,I}$. The deflection of B due to this angular change at N is equal to $x\,d\,\varphi = \frac{M\,x\,d\,x}{E\,I}$, and the total deflection at B is therefore given by the expression

$$y_1 = \int_A^B \frac{M\,x\,d\,x}{E\,I}. \quad . \quad . \quad . \quad . \quad . \quad . \quad . \quad (5)$$

Equation (5) can also be readily derived from eq. (22), Art. 214, of

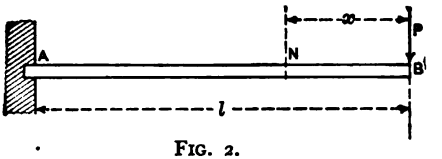

FIG. 2.

Part I, which expresses the deflection in terms of work. For point B this becomes $y_1 = \int_A^B \frac{M\,d\,x}{E\,I} \cdot m$, in which m is the bending moment at any point due to a load unity acting at the point B. In this case $m = x$, hence we have $y_1 = \int_A^B \frac{M\,x\,d\,x}{E\,I}$, as in eq. (5).

4. **Examples.**—The application of eqs. (3) and (5) will be illustrated by the solution of three simple problems.

1. Cantilever, supporting a load P, Fig. 2. Required the deflection of point B and the inclination at this point. Assume E and I constant.

Here $M = P\,x$ and the deflection is

$$y_1 = \int_A^B \frac{M\,x\,d\,x}{E\,I} = \frac{P}{E\,I}\int_o^l x^2\,d\,x = \frac{P\,l^3}{3\,E\,I}.$$

The angular change at B is

$$\varphi_1 = \int_A^B \frac{M}{E\,I}\,d\,x = \frac{P}{E\,I}\int_o^l x\,d\,x = \frac{P\,l^2}{2\,E\,I}.$$

2. Required the deflection and inclination at B, Fig. 3, the load P being applied at a distance a from B. Measuring x from B we have $M = P\,(x - a)$ and

$$y_1 = \frac{P}{E\,I}\int_a^l (x-a)\,x\,d\,x = \frac{P}{6\,E\,I}\,(2\,l^3 - 3\,a\,l^2 + a^3).$$

Also $$\varphi_1 = \frac{P}{E\,I}\int_a^l (x-a)\,d\,x = \frac{P}{2\,E\,I}\,(l-a)^2.$$

This is the same as the value of φ at point C, the beam being straight from B to C.

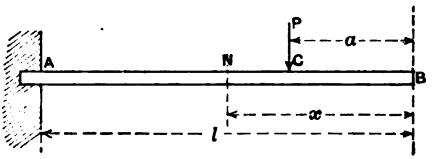

FIG. 3.

3. Beam loaded as shown in Fig. 4. Required the deflection of the centre point C. As the tangent at C remains horizontal the desired deflection will be found by calculating the upward movement of B with respect to C, Fig. (*a*).

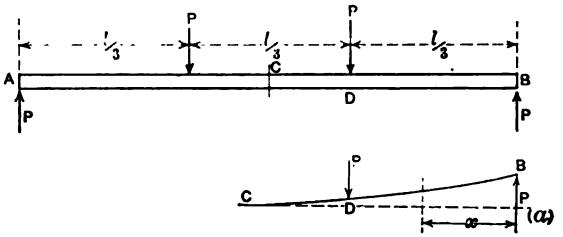

FIG. 4.

From B to D the value of M of eq. (5) is $P\,x$ and $\int\frac{M\,x\,d\,x}{E\,I} = \frac{P}{E\,I}\int_o^{l/3} x^2\,d\,x = \frac{1}{81}\frac{P\,l^3}{E\,I}$. From D to C, $M = \frac{P\,l}{3}$, and $\int\frac{M\,x\,d\,x}{E\,I} = \frac{P\,l}{3\,E\,I}\int_{l/3}^{l/2} x\,d\,x = \frac{5}{216}\frac{P\,l^3}{E\,I}$. The total deflection is therefore,

$$y_1 = \left(\frac{1}{81} + \frac{5}{216}\right)\frac{P\,l^3}{E\,I} = \frac{23}{648}\frac{P\,l^3}{E\,I}.$$

In a similar manner we find for the inclination at B,

$$\varphi_1 = \frac{1}{9}\frac{P\,l^2}{E\,I}.$$

Essentially the same calculations are required by the use of the general expression $y = \int\frac{M\,d\,x}{E\,I}\,.\,m$, noted in Art. 3. Applying this method to problem (3) the calculations are as follows:

From B to D: $M = P\,x$; $m = \frac{1}{2}\,x$; $\int_B^D \frac{M\,dx}{EI} \cdot m = \frac{P}{2}\int_o^{l/2} \frac{x^2\,dx}{EI} = \frac{1}{162}\,\frac{Pl^3}{EI}$.

From D to C: $M = \frac{Pl}{3}$; $m = \frac{1}{2}\,x$; $\int_D^C \frac{M\,dx}{EI} \cdot m = \frac{Pl}{6}\int_{l/2}^{l/2} x\,dx = \frac{5}{432}\,\frac{Pl^3}{EI}$.

Adding these and multiplying by two, to take account of the left half of the beam, we have $y_1 = 2\left(\frac{1}{162} + \frac{5}{432}\right)\frac{Pl^3}{EI} = \frac{23}{648}\,\frac{Pl^3}{EI}$, as found before.

Except for comparatively simple cases, as here illustrated, the general formula for deflection, $y = \int \frac{M\,dx}{EI} \cdot m$, will be the easier of application.

5. Graphical Calculation of Angular Change and Deflection.— Suppose $a\,a'\,b'\,b$, Fig. 5, to be a portion of the equilibrium polygon for

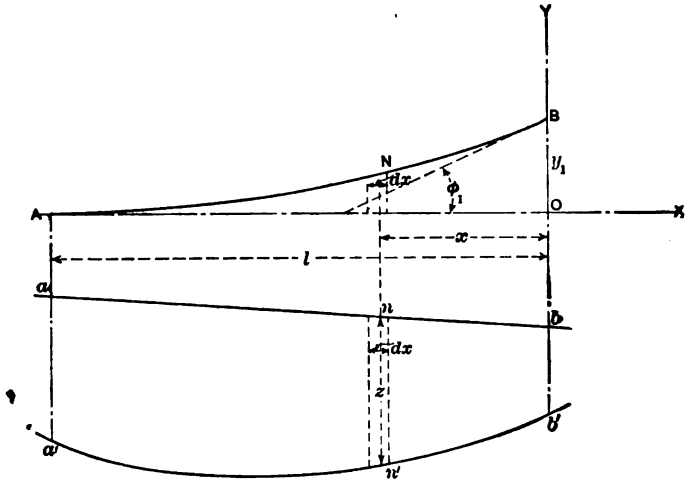

FIG. 5.

the forces acting upon the beam $A\,B$. In accordance with the principles explained in Art. 40, Part I, the bending moment M, at any point N, is given by the product of the ordinate $n\,n'$ and the pole distance H of the force polygon, or, in general, $M = H\,z$.

From Art. 2 the angular change over a length $d\,x$ is $d\,\varphi = \frac{M\,dx}{EI}$,

hence $d\varphi = \frac{H z\, dx}{EI}$, and the total angular change over the length $A\ B$ is

$$\varphi_1 = H \int_A^B \frac{z\, dx}{EI}. \quad . \quad . \quad . \quad . \quad . \quad . \quad . \quad (6)$$

If E and I are constant, we have

$$\varphi_1 = \frac{H}{EI} \int_A^B z\, dx = \frac{H}{EI} \times (\text{Area } a\ a'\ b'\ b), \quad . \quad . \quad (7)$$

that is, *the angular change between any two points is equal to the corresponding area of the equilibrium polygon, multiplied by $H/E\,I$.*

From eq. (5) the deflection of B with respect to a tangent at A is

$$y_1 = \int_A^B \frac{M x\, dx}{EI}. \quad \text{As in eq. (6), this becomes}$$

$$y_1 = H \int_A^B \frac{z x\, dx}{EI}. \quad . \quad . \quad . \quad . \quad . \quad . \quad . \quad . \quad . \quad . \quad (8)$$

For E and I constant, we have

$$y_1 = \frac{H}{EI} \int_A^B z\, x\, dx$$

$$= \frac{H}{EI} \times (\text{Moment of area } a\ a'\ b'\ b \text{ about } b\ b'), \quad . \quad . \quad (9)$$

that is, *the deflection of B with respect to a tangent at A is equal to the moment about B of the area of the corresponding portion of the equilibrium polygon, multiplied by $H/E\,I$.* The moment of this area is readily obtained graphically by constructing a second equilibrium polygon, using the ordinates of the polygon $a\ a'\ b'\ b$ as loads, as explained in Part I, Art. 41. The ordinate at B of this second polygon, multiplied by the new pole distance is the area-moment required. This second equilibrium polygon thus gives the deflection at any point and represents in fact the elastic curve of the beam.

A thorough understanding of the graphical method of analysis here explained will often enable the desired values of deflection or angular change to be written out by inspection. It is a convenient method of analysis for continuous girders, arches, and many other problems involving the deflection of beams.

6. Examples.—The graphical method will be applied to the examples analyzed in Art. 4.

(1.) Fig. 6 represents the beam and equilibrium polygon or moment diagram. Taking the pole distance, H, equal to unity, the ordinate $a\,a' = P\,l$.

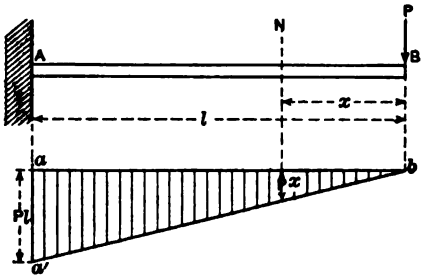

FIG. 6.

Then by eq. (7) the angular change = (Area $a\,a'\,b$) $\div\, E\,I = \frac{1}{2}\frac{P\,l^2}{E\,I}$. The deflection of B = (Moment of area $a\,a'\,b$ about B) $\div\, E\,I = (\frac{1}{2}\,P\,l^2 \times \frac{2}{3}\,l) \div E\,I = \frac{1}{3}\frac{P\,l^3}{E\,I}$, as found in Art 4.

(2.) (Fig. 7.) The angular change at C or B = (Area $a\,a'\,c$) $\div\, E\,I =$

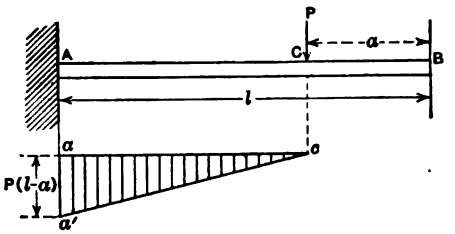

FIG. 7.

$\frac{P\,(l-a)^2}{2\,E\,I}$. The deflection at B = (Moment of area $a.a'\,c$ about B) $\div\, E\,I$ $= [\frac{1}{2}\,P\,(l-a)^2 \times (a + \frac{2}{3}\,(l-a))] \div E\,I = \frac{P}{6\,E\,I}\,(2\,l^3 - 3\,a\,l^2 + a^3)$.

(3.) (Fig. 8.) The moment diagram has ordinates at D and E equal to $\frac{P\,l}{3}$. The inclination at B = (Area $c\,c'\,b$) $\div\, E\,I = \frac{1}{9}\frac{P\,l^2}{E\,I}$. The deflection is equal to the sum of the moments about B of the areas $c\,c'\,d'\,d$ and $d\,d'\,b$,

divided by EI. Mom. of area $c\,c'\,d'\,d = \frac{1}{18} P l^2 \left(\frac{l}{3} + \frac{l}{12}\right) = \frac{5}{216} P l^2$, and mom. of area $d\,d'\,b = \frac{1}{18} P l^2 \times \frac{2}{9} l = \frac{1}{81} P l^3$. Hence the deflection

$$= \left(\frac{5}{216} + \frac{1}{81}\right) \frac{P l^3}{E I} = \frac{23}{648} \frac{P l^3}{E I}.$$

(4.) *Beam Fixed at the Ends.*—The method of calculating angular change and deflection above illustrated may be directly employed in the determination

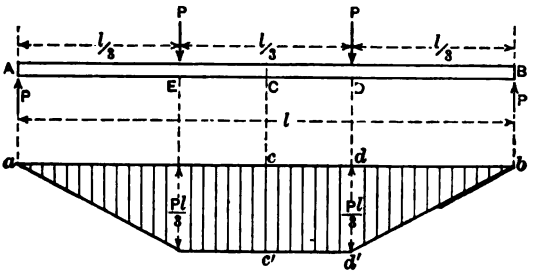

FIG. 8.

of reactions and bending moments in beams fixed at one or both ends. As an example, consider the beam $A\,B$, Fig. 9, fixed at A and B and supporting a single load P applied at a distance $k\,l$ from A. The unknowns are V_1, V_2, M_1 and M_2 (Fig. 10). From statics, $V_1 + V_2 = P$ and $M_1 + P\,k\,l - V_2\,l - M_2 = 0$. Two additional equations can be obtained by determining the total angular change from A to B and the deflection of B with respect to a tangent at A. Both of these quantities are zero, which conditions give the desired equations.

The semigraphic process explained in Art. 5 is very easily applied to this case. The moment diagram is of the form shown in Fig. 11. By eq. (7) the total angular change from A to B is given by the sum of the shaded areas in Fig. 11, and the total deflection is equal to the sum of the moments of these areas about b. The triangle $a'\,c'\,b'$ represents the bending moments in a simply supported beam, the ordinate $c'\,c''$ being equal to $P\,l\,k\,(1 - k)$; call this M'. Let z_1 and z_2 represent the ordinates at a and b. The sum of the shaded areas = area of triangle $a'\,c'\,b'$, minus the area of the trapezoid $a\,a'\,b'\,b$ or

$$\Sigma\,(\text{areas}) = \tfrac{1}{2} M' l - \left(\frac{z_1 + z_2}{2}\right) l = 0. \quad . \quad . \quad . \quad . \quad . \quad (a)$$

The lever arms of these two areas about B are, for the triangle, $\frac{2\,l - k\,l}{3}$, and for the trapezoid, $\frac{2\,z_1 + z_2}{z_1 + z_2} \times \frac{l}{3}$. Multiplying the areas by these lever arms and equating to zero, we get

$$\tfrac{1}{2} M' l \times \frac{2l - kl}{3} - (2z_1 + z_2)\frac{l^2}{6} = 0. \quad . \quad . \quad . \quad . \quad . \quad (b)$$

Solving (a) and (b) for z_1 and z_2 we derive

$$z_1 = M_1 = M'(1 - k); \text{ and } z_2 = M_2 = M'k. \quad . \quad . \quad . \quad (10)$$

That is, the bending moments at A and B may be considered as equal to the

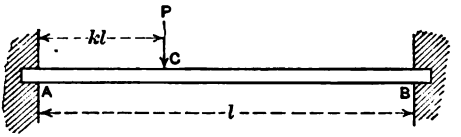

FIG. 9.

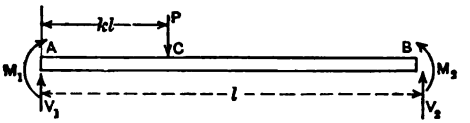

FIG. 10.

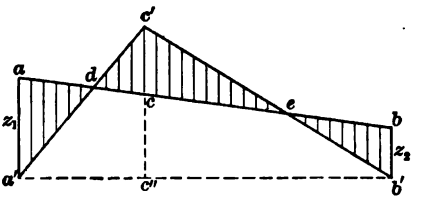

FIG. 11.

moment at C in a simple beam, divided between A and B inversely as the distances kl and $(l - kl)$, or as the reactions of a simple beam.

7. Table of Moments, Stresses, and Deflections.—The table on pp. 10–13 gives values of moments, stresses, and deflections for various commonly occurring cases of beams, both simply supported and continuous. The values of deflection in terms of maximum fibre stress are very useful in problems in which the deflection may be the known factor.

8. Deflection Due to Shear.—In the theory of flexure presented in the preceding articles the effect of shearing strains has been neglected, the equations of the elastic curves being derived from a consideration of compressive and tensile strains only. In the case of beams of the

TABLE NO. 1

MOMENTS, STRESSES, AND DEFLECTION OF BEAMS

The Beam and its Load with the Moment and Shear Diagrams.	Moment Equation and Maximum Moment. M_x and $M_{max.}$	Equation of Elastic Line, and Maximum Deflection in Terms of the Loading. y and Δ.	Maximum Deflection in Terms of Stress on Extreme Fibre of Symmetrical Sections. Δ.	Maximum Stress on Extreme Fibre in Terms of the Loading, Symmetrical Sections. f.
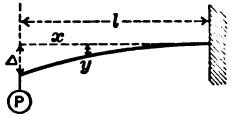	$M_x = -Px$ $M_{max.} = -Pl$	$y = \frac{P}{6EI}[2l^3 - 3l^2x + x^3]$ $\Delta = \frac{Pl^3}{3EI}$	$\frac{2fl^2}{3Eh}$	$\frac{Plh}{2I}$
	$M_x = -\frac{px^2}{2}$ $M_{max.} = -\frac{pl^2}{2}$	$y = \frac{p}{24EI}[x^4 - 4l^3x + 3l^4]$ $\Delta = \frac{Pl^4}{8EI}$	$\frac{fl^2}{2Eh}$	$\frac{pl^2h}{4I}$

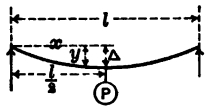	$M_x = \frac{P}{2}x$ $M_{max.} = \frac{Pl}{4}$	$y = \frac{Px}{48EI}[3l^2 - 4x^2]$ $\Delta = \frac{Pl^3}{48EI}$	$\frac{fl^2}{6Eh}$	$\frac{Plh}{8I}$
	$M_x = \frac{px}{2}(l-x)$ $M_{max.} = \frac{pl^2}{8}$	$y = \frac{px}{24EI}[l^3 - 2lx^2 + x^3]$ $\Delta = \frac{5pl^4}{384EI}$	$\frac{5}{24}\frac{fl^2}{Eh}$	$\frac{pl^2h}{16I}$
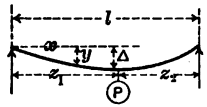	$x < z_1$ $M_x = \frac{Pz_2x}{l}$ $x > z_1$ $M_x = \frac{Pz_2x}{l} - P(x-z_1)$ $M_{max.} = \frac{Pz_1z_2}{l}$	$x < z_1$ $y = \frac{Pz_2x}{6EIl}[2lz_1 - z_1^2 - x^2]$ $x > z_1$ $y = \frac{Pz_1(l-x)}{6EIl}[2lx - x^2 - z_1^2]$ $\Delta = \frac{Pz_2}{27EIl}\sqrt{3[z_1(2z_2+z_1)]^3}$ for $x = \frac{1}{3}\sqrt{3[z_1(2z_2+z_1)]}$	$\frac{f}{27Eh}\sqrt{3z_1(2z_2+z_1)^3}$	$\frac{Pz_1z_2h}{2Il}$

TABLE NO. 1—(*Continued*)

MOMENTS, STRESSES, AND DEFLECTION OF BEAMS.

The Beam and its Load with the Moment and Shear Diagrams.	Moment Equation and Maximum Moment. M_x and M_{max}.	Equation of Elastic Line, and Maximum Deflection in Terms of the Loading. y and Δ.	Maximum Deflection in Terms of Stress on Extreme Fibre of Symmetrical Sections. Δ.	Maximum Stress on Extreme Fibre in Terms of the Loading, Symmetrical Sections. f.
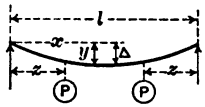	$x < z$ $M_x = P\,x$ $x > z$ $M = P\,z = M_{max.}$	$x < z$ $y = \frac{P\,x}{6\,E\,I}[3\,l\,z - 3\,z^2 - x^2]$ $x > z$ $y = \frac{P\,z}{6\,E\,I}[3\,l\,x - 3\,x^2 - z^2]$ $\Delta = \frac{P\,z}{6\,E\,I}\left[\frac{3}{4}\,l^2 - z^2\right]$	$\frac{f}{3\,E\,h}\left[\frac{3}{4}\,l^2 - z^2\right]$	$\frac{P\,z\,h}{2\,I}$
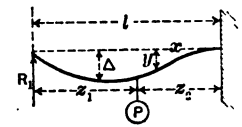	$R_1 = \frac{P}{2\,l^3}[3\,l\,z_2^2 - z_2^3]$ $x < z_2$ $M_x = R_1\,(l - x)$ $\quad - P\,(z_2 - x)$ $x > z_2$ $M_x = R_1\,(l - x)$ $M_{max.} = R_1\,(l - z_2)$ for $x = z_2$	$x < z_2$ $y = \frac{1}{6\,E\,I}[R_1\,x^3 - 3\,R_1\,l\,x_2$ $\quad + 3\,P\,z_2\,x^2 - P\,x^3]$ $x > z_2$ $y = \frac{1}{6\,E\,I}R_1\,x_1^3 - 3\,R_1\,l\,x^2$ $\quad + 3\,P\,z_2^2\,x - P\,z_2^3]$ $\Delta = \frac{P\,z_2^2}{6\,E\,I}(l - z_2)\sqrt{\frac{l - z_2}{3\,l - z_2}}$ for $x = l\left(1 - \sqrt{\frac{l - z_2}{3\,l - z_2}}\right)$	$\frac{2\,f}{3\,E\,h}\sqrt{(3\,l - z_2)\,(l - z_2)}$	$\frac{P\,h}{4\,I^2}(3\,l\,z_2^2 - z_2^3)\,(l - x)$

	$R_1 = \frac{3}{8} p l$ $M_x = \frac{p}{8}(4x - l)(l - x)$ $M_{max.} = -\frac{p l^2}{8}$ for $x = 0$	$y = \frac{p x^3}{48 E I}(l - x)(3l - 2x)$ $\Delta = 0.0054 \frac{p l^4}{E I}$ for $x = 0.578 l$	$\frac{0.0864 f l^2}{E h}$	$\frac{p l^2 h}{16 l}$
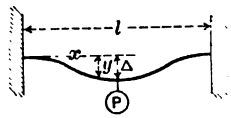	$M_x = \frac{P x}{2} - \frac{P l}{8}$ $M_{max.} = \frac{P l}{8}$ for $x = 0$ and $x = \frac{l}{2}$	$y = \frac{P}{8 E I}\left(\frac{2x^3}{3} - \frac{l x^2}{2}\right)$ $\Delta = \frac{P l^3}{192 E I}$	$\frac{f l^2}{12 E h}$	$\frac{P l h}{16 l}$
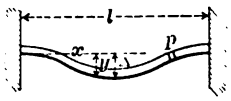	$M_x = \frac{p}{2}(lx - x^2) - \frac{p l^2}{12}$ $M_{max.} = \frac{p l^2}{12}$ for $x = 0$	$y = \frac{p}{12 E I}\left(lx^3 - \frac{x^4}{2} - \frac{l^2 x^2}{2}\right)$ $\Delta = \frac{p l^4}{384 E I}$	$\frac{f l^2}{8 E h}$ (f at centre)	$\frac{p l^2 h}{24 l}$ (f at end)

usual proportions the deflection due to shear is small and generally negligible, but for very short beams it requires consideration. It is also important that the influence of this factor be recognized in dealing with trusses by means of formulas developed for solid beams.

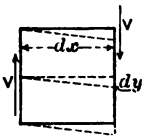

FIG. 12.

The modulus of elasticity for shear is the ratio of the shearing stress per unit area to the angular distortion. Let Fig. 12 represent a short length of a beam. If A = area of cross-section, V = total shear on the section and E_s = shearing modulus, we have, for the deflection of the element,

$$dy = \frac{V}{E_s A} . dx. \quad . \quad . \quad . \quad . \quad . \quad . \quad . \quad (11)$$

Integrating this between any given sections A and B of a beam, we have, for beams of uniform section, the deflection due to shear

$$y_s = \frac{1}{E_s A}\int_A^B V\,dx \quad . \quad . \quad . \quad . \quad . \quad . \quad . \quad (12)$$

For a cantilever beam loaded as in Fig. 6, $V = P$ and $y_s = \frac{Pl}{E_s A}$. For a beam supporting a load P at the centre, the deflection due to shear is $y_s = \frac{1}{4}\frac{Pl}{E_s A}$. For a beam uniformly loaded $V = pl/2 - px$, and integrating $V\,dx$ from o to $\frac{l}{2}$ we get, for the centre point, $y_s = \frac{pl^2}{8 E_s A}$. The deflection curve due to shear is a straight line where V is constant and a parabolic curve where V varies uniformly.

The relative effects of shear and moment may be illustrated by comparing the results for the two cases of a single concentrated load, and a uniformly distributed load. If y_m = deflection due to moment and y_s = deflection due to shear we have:

For a concentrated load at the centre

$$\frac{y_s}{y_m} = \frac{12\,EI}{E_s A\,l^2}.$$

For a uniform load

$$\frac{y_s}{y_m} = \frac{48\,EI}{5\,E_s A\,l^2}.$$

For steel E_s is approximately 0.4 E, and $I/A = r^2$. Hence for the two cases $y_s/y_m = 30\frac{r^2}{l^2}$ and $24\frac{r^2}{l^2}$ respectively. For plate girders r = one-half the depth, and for a ratio of depth to span of 1:10 the values of y_s/y_m become equal to 7.5% and 6% respectively; that is, the deflection due to shear is in these cases 7.5% and 6% of that due to moment. In deeper beams the ratio is larger, and in ordinary trusses it reaches a proportion too large to be neglected.

SECTION II.—CONTINUOUS GIRDERS

9. Definition.—A continuous girder is a beam or truss which is supported at more than two points. In such a case the reactions depend upon the form of the structure as well as upon the loads and cannot be determined from the principles of statics alone; it is necessary to take into account the dimensions and material of the structure itself. All supports in excess of two are redundant, in the sense employed in Chap. VII of Part I, and methods of analysis must be applied similar to those used in that chapter.

In the analysis and design of continuous girders it is necessary to assume certain proportions or dimensions before the stresses can be determined. If the girder is to be made of uniform section the problem is relatively simple, but if it is to vary from point to point an exact solution is very laborious and generally not fully accomplished. In such cases an approximate solution is made to suffice. In the following analysis, certain formulas will first be derived for beams of solid section; the application of these formulas to trusses will be considered subsequently.

10. Shear and Bending Moment in Any Span.—Let $A\,B\,C\,D$, Fig. 13, be a continuous girder of any number of spans and loaded in any manner. Consider any span, as $A\,B$, passing sections p and q, close to the reactions. Fig. 14 shows this span separated and all forces indicated. M_1 and M_2 are the bending moments at the two supports, V_1 the shear on the right of A and V_2' the shear on the left of B. P is any load distant $k\,l$ from A. Taking moments about A we have

$$V_2' = \frac{M_1 - M_2 + P\,k\,l}{l}. \quad . \quad . \quad . \quad . \quad . \quad (1)$$

Taking moments about B we have

$$V_1 = \frac{M_2 - M_1 + P\,(l - k\,l)}{l}. \quad . \quad . \quad . \quad . \quad . \quad (2)$$

Again, the bending moment at any point N distant x from A is

$$\left.\begin{aligned} &\text{for } x < k\,l, \quad M_x = M_1 + V_1\,x \\ &\text{for } x > k\,l, \quad M_x = M_1 + V_1\,x - P\,(x - k\,l) \end{aligned}\right\} \quad . \quad . \quad (3)$$

and the shear at N is

$$\left.\begin{aligned} &\text{for } x < k\,l, \quad V_x = -\,V_1 \\ &\text{for } x > k\,l, \quad V_x = -\,V_1' + P \end{aligned}\right\} \quad . \quad . \quad . \quad . \quad . \quad (4)$$

Equations (1) to (4) show that the bending moments and shears at any section of a continuous girder are easily found when the moments

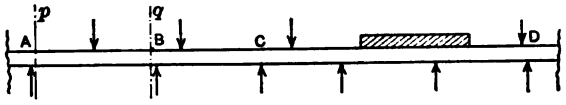

FIG. 13.

at the supports are known. Similar formulas can readily be written out for uniform loads.

11. **The Theorem of Three Moments.**—Referring again to Fig. 13, which represents a continuous girder of any number of spans and loaded in any manner (loads vertical), let us consider any two consecu-



FIG. 14.

tive spans as A–B–C. The theorem of "three moments," which will now be derived, in an equation expressing the relation between the bending moments at the three supports, A, B and C, and the loads on the two included spans, a relation which is independent of the loads on

any other part of the structure. This theorem will be derived, first, for concentrated loads, and secondly, for uniform loads.

12. *Concentrated Loads.*—Fig. 15 shows the two spans in question, separated by sections passed close to the supports at A and C. The supports are numbered 1, 2, and 3 and the span lengths are l_1 and l_2.

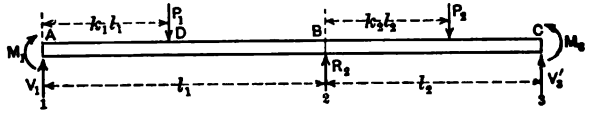

FIG. 15.

The centre reaction is R_2 and the end moments are M_1 and M_3. These are shown as positive in order that the signs will be correctly given in applying any resulting formulas.

Consider first a single load P on each span. Let $k_1 l_1$ = distance

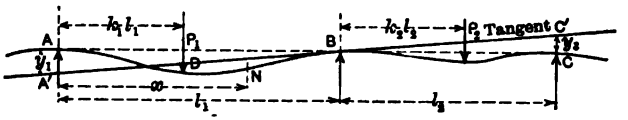

FIG. 16.

of P_1 from A, and $k_2 l_2$ = distance of P_2 from B, the coefficient k representing the ratio of $k\,l/l$ in general for any load. Fig. 16 represents the curved form of the elastic line, and $A'C'$ the tangent at B. The deflections at A and C with respect to the tangent are y_1 and y_3.

From eq. (5), Art. 3, $y_1 = \int_A^B \frac{M\,x\,dx}{EI}$, in which M is the bending moment at any point N. Substituting the value of M from eq. (3), integrating from A to D and from D to B, and finally replacing V_1 by its value given in eq. (2), we derive

$$y_1 = \frac{M_1 l_1^2 + 2\,M_2 l_1^2 + P_1 l_1^3 (k - k^3)}{6\,EI}. \quad . \quad . \quad . \quad (5)$$

In a similar manner we find for span BC, origin at C,

$$y_3 = \frac{M_3 l_2^2 + 2\,M_2 l_2^2 + P_2 l_2^3 (2\,k - 3\,k^2 + k^3)}{6\,EI}. \quad . \quad . \quad (6)$$

If the supports at A, B and C remain at a fixed level then, with due attention paid to sign, we have $\frac{y_1}{l_1} = -\frac{y_3}{l_2}$, whence we derive from (5) and (6) the relation

$$M_1 l_1 + 2M_2(l_1+l_2) + M_3 l_2 = -P_1 l_1^2(k-k^3) - P_2 l_2^2(2k-3k^2+k^3) \quad . \quad (7)$$

If there are several loads on each span a similar equation may be written out for each load and, by addition, we have the general *equation of three moments* for any number of concentrated loads.

$$M_1 l_1 + 2M_2(l_1+l_2) + M_3 l_2 = -\Sigma P_1 l_1^2(k-k^3) - \Sigma P_2 l_2^2(2k-3k^2+k^3) \quad . \quad (8)$$

13. Uniform Loads.—If the spans are loaded with a uniformly distributed load of p_1 and p_2 per unit length, respectively, then in eq. (8) P may, in general, be replaced by $p\,d\,x$ and k by $\frac{x}{l}$. Then integrating each of the terms in the second member from o to l we have, for *uniform loads*

$$M_1 l_1 + 2M_2(l_1+l_2) + M_3 l_2 = -\tfrac{1}{4} p_1 l_1^3 - \tfrac{1}{4} p_2 l_2^3 \quad . \quad (9)$$

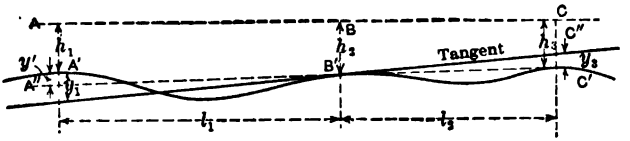

FIG. 17.

14. Effect of Movement of Supports.—In Fig. 16 the elevation of the supports was assumed as fixed. If, however, their relative elevation changes, due to unequal settlement or imperfect adjustment, the values y_1 and y_3 will be modified accordingly. In Fig. 17 let A, B and C represent the initial position of the supports. Suppose that the support at A settles a distance h_1, the support at B a distance h_2 and that at C a distance h_3. Unless these movements are equal or proportional the beam will be bent out of its original form by such settlement. This effect

may be measured by the ordinate y' at A', from the support A' to the straight line $A''\,B'\,C'$ drawn through B' and C'. By similar triangles

$$\frac{y' + h_1 - h_2}{l_1} = \frac{h_2 - h_3}{l_2}, \quad . \quad . \quad . \quad . \quad . \quad . \quad (10)$$

whence

$$y' = (h_2 - h_3)\frac{l_1}{l_2} + h_2 - h_1. \quad . \quad . \quad . \quad . \quad . \quad (11)$$

Then, as in Art. 12, $\frac{y_1 - y'}{l_1} = -\frac{y_3}{l_2}$. Substituting the values of y_1 and y_3 from (5) and (6) we derive, finally, for any number of loads

$$M_1 l_1 + 2 M_2 (l_1 + l_2) + M_3 l_2 =$$
$$- \Sigma P_1 l_1^2 (k - k^3) - \Sigma P_2 l_2^2 (2k - 3k^2 + k^3)$$
$$- 6 E I \left(\frac{h_1 - h_2}{l_1} + \frac{h_3 - h_2}{l_2}\right) \quad . \quad . \quad . \quad . \quad . \quad . \quad . \quad (12)$$

as the equation of three moments which takes account of a settlement of supports.

Generally we speak of the supports as being *level* or *out of level*, but if the supports are fixed and the beam is built to conform to their elevation, even though they be at different levels, there will be no stress resulting from such variation. It is only a variation in level from the original or normal position that is significant. The fact that such a

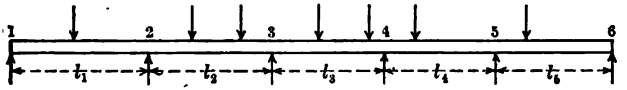

FIG. 18.

variation or settlement of supports causes large stresses in a continuous girder constitutes a serious objection to its use in practice.

15. Calculation of Moments at Supports.—The theorem of three moments enables the bending moments due to any given loading to be calculated in any continuous girder of any number of spans. This is accomplished by the successive application of the theorem to each group of two consecutive spans, this process furnishing as many equa-

tions as there are unknown moments. Thus, for a girder of five spans, Fig. 18, the theorem written out for spans 1 and 2, 2 and 3, 3 and 4, 4 and 5, gives four equations. The moments at 1 and 6 being zero, there are but four unknown moments, which are readily found by solving these four equations. The moments at the supports being determined the moments and shears at intermediate sections are derived as in Art. 10.

In the case of fixed ends, the theorem may still be applied by con-

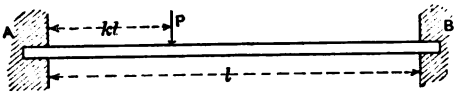

FIG. 19.

sidering the fixed end as equivalent to an additional span of length zero. Thus let *A B*, Fig. 19, be a beam fixed at the ends and supporting a single load *P*. Fig. 20 shows this as a three-span continuous girder,

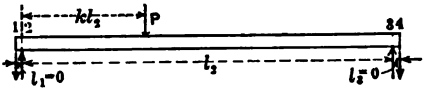

FIG. 20.

the values of l_1 and l_3 being indefinitely small. Applying eq. (8) we have, for spans l_1 and l_2 (noting that $M_1 = 0$, and $l_1 = 0$),

$$2 M_2 l_2 + M_3 l_2 = - P l_2^2 (2 k - 3 k^2 + k^3). \quad . \quad . \quad (a)$$

And applying to spans 2 and 3 (noting that $M_4 = 0$ and $l_3 = 0$),

$$M_2 l_2 + 2 M_3 l_2 = - P l_2^2 (k - k^3). \quad . \quad . \quad . \quad (b)$$

Solving (*a*) and (*b*) for M_2 and M_3 we have

$$\left.\begin{aligned} M_2 &= - P l (k - 2 k^2 + k^3) \\ \text{and } M_3 &= - P l (k^2 - k^3) \end{aligned}\right\} \quad . \quad . \quad . \quad . \quad (13)$$

These results are the same as given in eq. (10), Art. 6, the value of M' of that article being equal to $P l (k - k^2)$.

16. General Formulas for Moments at Supports.—The result of the application of the theorem of three moments in the manner explained

above, to a girder of any number of spans, may be expressed in a general formula for the moment at any given support. Such a formula will be here given for both uniform and concentrated loads, spans all equal.

Let n = whole number of spans;
m = number of support in question, counting from the left;
r = number of any span in which a load occurs;
c = a coefficient, tabulated below.

(*a*) *Uniform Load on Any Span.*—For the case where one or more spans are uniformly loaded with a load p per unit length, the bending moment at the mth support is

$$M_m = -\frac{pl^2}{4(c_{n-1}+4c_n)}[\Sigma(c_r+c_{r+1})c_{n-m+2}+\Sigma(c_{n-r+2}+c_{n-r+1})c_m]. \quad (14)$$

(For loaded spans on left.) (For loaded spans on right.)

The following values are to be used for the c coefficients:

$c_1 = 0$	$c_5 = -56$	$c_9 = -10{,}864$
$c_2 = +1$	$c_6 = +209$	$c_{10} = +40{,}545$
$c_3 = -4$	$c_7 = -780$	$c_{11} = -151{,}316$
$c_4 = +15$	$c_8 = +2{,}911$	$c_{12} = +564{,}719$

following the law that $c_m = -4c_{m-1} - c_{m-2}$.

As an example, let it be required to find the value of M_2 for a girder of four equal spans, loaded as shown in Fig. 21. Here $m = 2$, $n = 4$. For

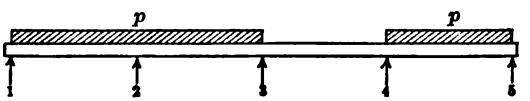

FIG. 21.

loads on the left of the 2nd support, $r = 1$, and for loads on the right, $r = 2$ and 4. Eq. (14) then becomes

$$M_2 = -\frac{pl^2}{4(c_3+4c_4)}[(c_1+c_2)c_4+(c_4+c_3)c_2+(c_2+c_1)c_2].$$

Substituting the values of c we have $M_2 = -\frac{27}{224}pl^2$.

(*b*) *Uniform Load on All Spans.*—For this case eq. (14) reduces to

$$M_m = \left[\frac{c_{n+1}(c_{m+1}-1) - c_m(c_{n+2}-1)}{c_{n+1}}\right]\frac{p\,l^2}{12}. \quad . \quad (15)$$

This formula is evaluated in the following diagram for all supports for girders of seven spans or less.

MOMENTS AT SUPPORTS; TOTAL UNIFORM LOAD; SPANS ALL EQUAL. COEFFICIENTS OF $(-p\,l^2)$.

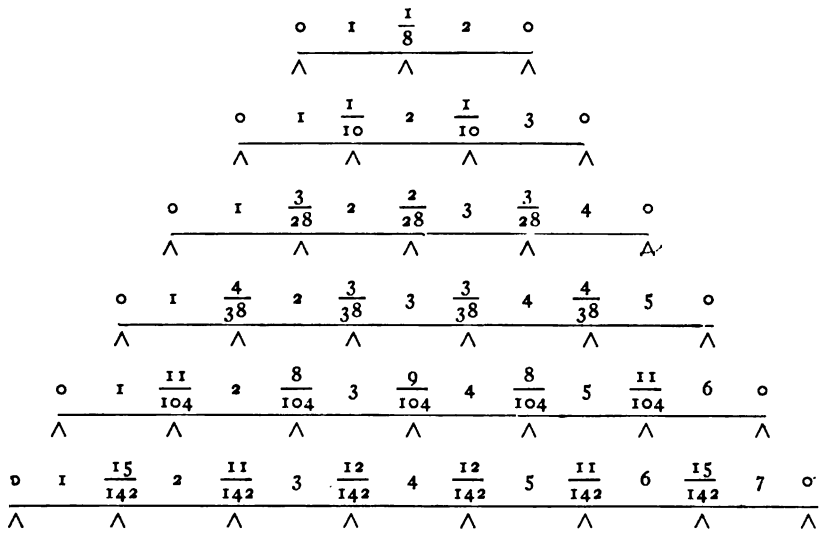

(*c*) *Concentrated Loads on any Span.*—For the case where one or more spans are loaded with concentrated loads,

$$M_m = -\frac{l}{c_{n-1}+4c_n}\Big[\Sigma\left\{\Sigma P(2k-3k^2+k^3)c_r + \Sigma P(k-k^3)c_{r+1}\right\}c_{n-m+2}$$

(For loaded spans on left of mth support.)

$$+\Sigma\left\{\Sigma P(2k-3k^2+k^3)c_{n-r+2} + \Sigma P(k-k^3)c_{n-r+1}\right\}c_m\Big]. \quad . \quad (16)$$

(For loaded spans on right of mth support.)

If both uniform and concentrated loads are found upon the same

span, then both (14) and (16) must be used. When more than one span is loaded, the data must be worked out for each, and the sum taken, as indicated by the primary signs of summation. The secondary summa-

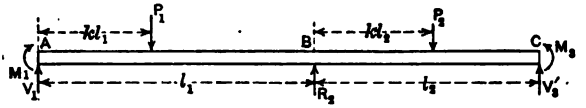

FIG. 22.

tion signs for concentrated loads signify the summation for the several concentrated loads in any one span.

17. General Formula for Reactions.—It is convenient to find the reactions directly from the moments at the supports. Fig. 22 repre-

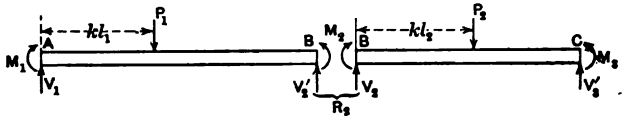

FIG. 23.

sents any two consecutive spans. Let R_2 = reaction at the middle support. In Fig. 23, $R_2 = V_2' + V_2$. By eq. (1), $V_2' = \frac{M_1 - M_2}{l_1} + P_1 k$, and by eq. (2), $V_2 = \frac{M_3 - M_2}{l_2} + P_2 (1 - k)$, whence

$$R_2 = \frac{M_1 - M_2}{l_1} + \frac{M_3 - M_2}{l_2} + P_1 k + P_2 (1 - k). \quad . \quad (17)$$

Note that the last two terms of (17) give the total reaction at B for two simple spans. For uniform loads these terms become $\frac{p_1 l_1}{2}$ and $\frac{p_2 l_2}{2}$.

The following gives the shears on each side of the supports for the case of uniform load over the entire girder. The supporting force is the sum of the two shears at that support.

SHEARS AT SUPPORTS; TOTAL UNIFORM LOAD; SPANS ALL EQUAL
COEFFICIENTS OF $(p\,l)$.

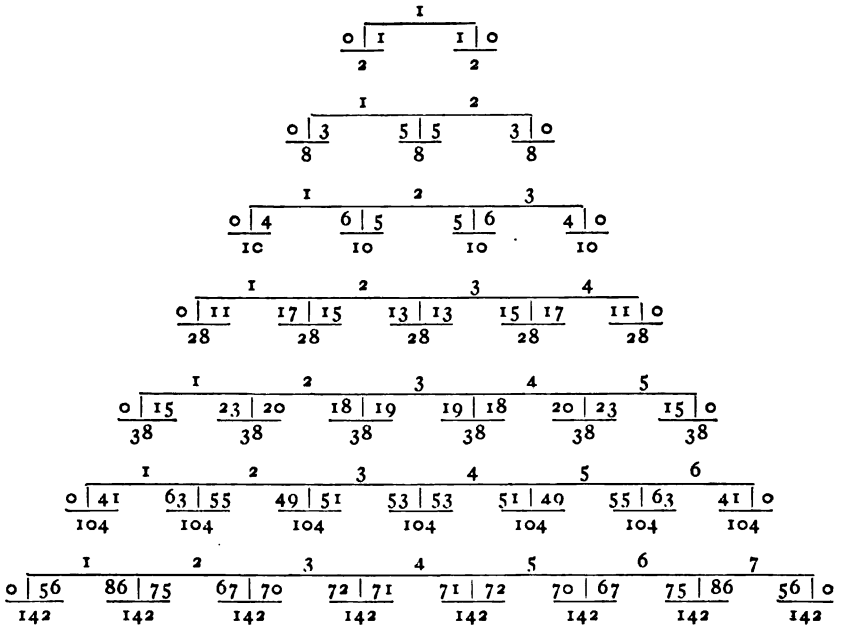

18. Continuous Girder of Two Equal Spans.—*Uniform Load on Both Spans.*—(Fig. 24.) For a uniform load of p per unit length on both spans we have from eq. (9), noting that $M_1 = 0$, $M_3 = 0$ and $p_1 = p_2 = p$,

$$M_2 = -\tfrac{1}{8}\,p\,l^2. \quad . \quad . \quad . \quad . \quad . \quad . \quad . \quad (18)$$

Then we readily find

$$\left.\begin{aligned} R_1 = R_3 &= \tfrac{3}{8}\,p\,l, \\ R_2 &= \tfrac{5}{4}\,p\,l, \end{aligned}\right\} \quad . \quad . \quad . \quad . \quad . \quad . \quad . \quad (19)$$

The bending moment at any distance x from A is

$$M_x = R_1\,x - \frac{p\,x^2}{2} = \frac{p}{8}\,(3\,l\,x - 4\,x^2). \quad . \quad . \quad . \quad (20)$$

The shear is,

$$V_x = R_1 - p\,x = \frac{p}{8}\,(3\,l - 8\,x). \quad . \quad . \quad . \quad . \quad (21)$$

The variation in moment and shear is shown in Figs. 24, (*b*) and (*c*) The maximum positive moment occurs for zero shear, or for $x = \frac{3}{8}\,l$, and zero moment for $x = \frac{3}{4}\,l$.

19. *Uniform Load on One Span.*—(Fig. 25.) Applying eq. (9),

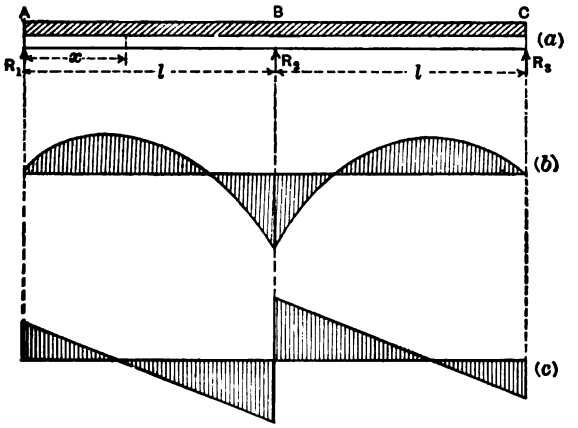

FIG. 24.

$p_2 = 0$, and the value of M_2 is one-half that given by (18), or

$$M_2 = -\frac{1}{16}\,p\,l^2. \qquad (22)$$

Then, as before,

$$\left.\begin{aligned} R_1 &= \frac{7}{16}\,p\,l;\ R_3 = -\frac{1}{16}\,p\,l, \\ R_2 &= +\frac{5}{8}\,p\,l. \end{aligned}\right\} \qquad (23)$$

The variation in moment and shear is represented in Fig. 25. Maximum moment occurs for $x = \frac{7}{16}\,l$, and zero moment for $x = \frac{7}{8}\,l$.

20. *Single Concentrated Load on One Span.—Reactions.*—(Fig. 26.) For a single load P on the first span we find, from eq. (7), noting that $M_1 = 0$, $M_3 = 0$, $P_2 = 0$, and $l_1 = l_2 = l$,

$$M_2 = -\frac{P\,l}{4}\,(k - k^3). \qquad (24)$$

and from this we derive

$$\left.\begin{aligned} R_1 &= \frac{P}{4}(4 - 5k + k^3), \\ R_2 &= \frac{P}{2}(3k - k^3), \\ R_3 &= -\frac{P}{4}(k - k^3). \end{aligned}\right\} \quad \ldots\ldots \quad (25)$$

Moments. The moments vary as shown in Fig. 26 (*b*). Between A and D, $M = R_1 x$, and is always positive.

From D to B, $M = R_1 x - P(x - kl) = P(kl - \frac{5}{4} kx + \frac{1}{4} k^3 x)$.

This value varies from positive to negative, becoming zero at E for a value of x given by the equation

$$x_o = \frac{4l}{5 - k^2} \quad \ldots\ldots\ldots \quad (26)$$

In the second span the moment is negative throughout.

For larger values of k the point of inflection, E, lies farther to the

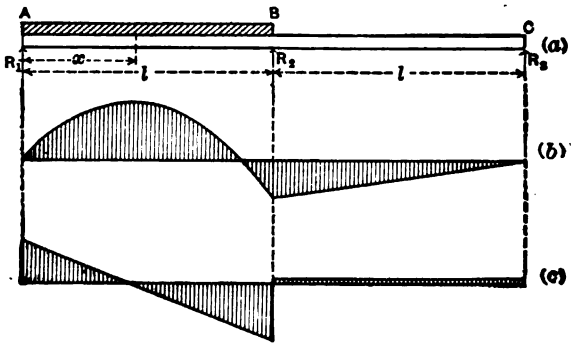

FIG. 25.

right, being located always between the load and the centre support; for smaller values of k the point E lies farther to the left, the least value of x_o of eq. (26) being 0.8 l.

Shears. The shears are readily deduced from the value of R_1. They are represented in Fig. 26 (*c*).

21. *Influence Lines for Moments and Shears.* (*a*) *Moments.*— The position of moving uniform loads for maximum moments can readily be deduced from the preceding equations. It will be of assist-

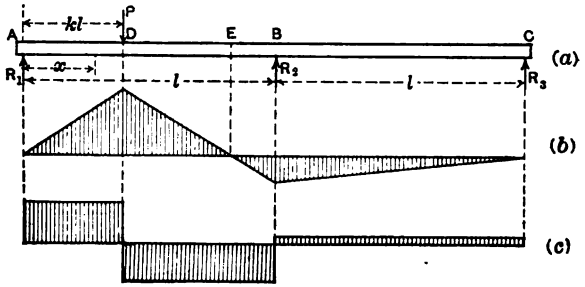

FIG. 26.

ance, however, to construct influence lines for two or three points. Such lines are almost indispensable if calculations are to be made for concentrated loads.

In Fig. 27 consider any section D in the first span, whose distance

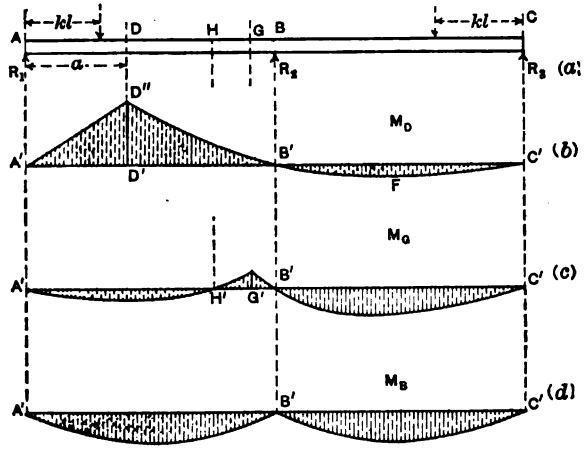

FIG. 27.

from A is less than 0.8 l. For a load on span BC, $M_D = R_1 a$. The value of R_1 is given by the expression for R_3 in eq. (25), in which $k l$ is to be measured from C. Hence $M_D = -\frac{1}{4} P (k - k^3) a$. This

moment is represented by the curve $C' F B'$, Fig. (*b*). For a load between B and D, R_1 is directly given by eq. (25), and $M_D = R_1 a = \frac{P a}{4}(4 - 5k + k^3)$. This moment is represented by the curve $B' D''$, a continuation of the curve $F B'$. On the left of D, $M_D = R_1 a - P(a - k l)$. Eq. (25) gives R_1. The curve $D'' A'$ represents this moment, thus giving the complete influence line $C' F B' D'' A'$. Note that since the reactions are functions of the third degree with

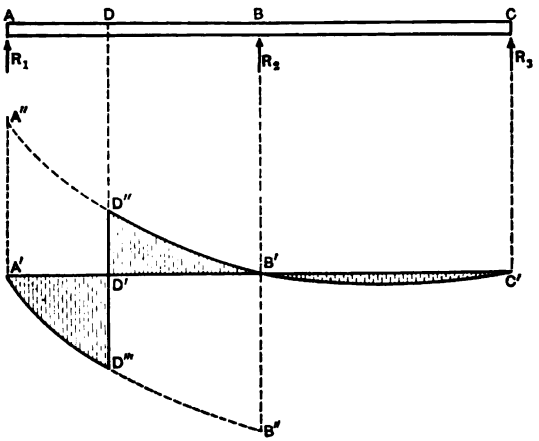

FIG. 28.

respect to k the influence line is no longer a series of straight lines, as in the case of simple structures, but consists of arcs of curves.

If the point D lies near B, so that $\frac{a}{l} > 0.8$, then, as shown by eq. (26) and Fig. 26, the moment at D will be zero for a certain position of the unit load. When the load is on the left of such position the moment at D will be negative and when the load is on the right it will be positive. Take a point G such that the distance $A G = 0.9\, l$. The influence line is shown in Fig. 27 (*c*). For loads between G and A it will be found that at some point H the moment at G' will be zero, and for loads to the left it will be negative, giving the form of influence line as shown. The value of k, such that the moment at G will be zero, may be found

by placing $x_o = 0.9\,l$ in eq. (26) and solving for k. This gives $k = \sqrt{5/9} = .745$. Notice the relatively small effect of the load from A to H. The influence line for moment at B is given in Fig. 27 (*d*).

The relative values of the maximum bending moments are well shown by the areas of the influence diagrams. For uniform moving loads they give directly the correct positions and values; for concentrated loads the method of determining positions and maximum

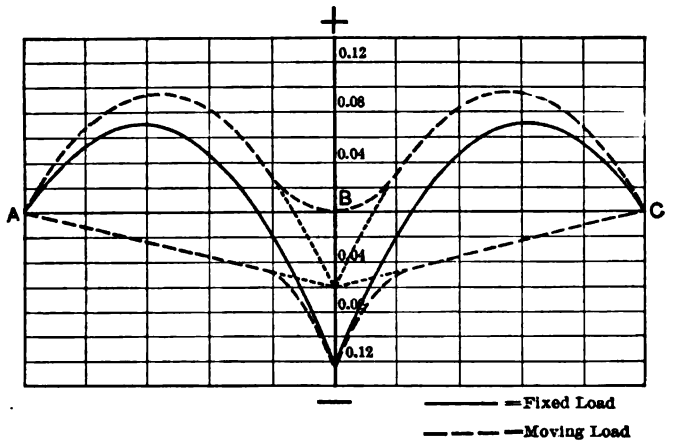

FIG. 29.—Moments in a Two-Span Continuous Girder.

moments by trial is the most expeditious. This is illustrated in the next chapter.

(*b*) *Shears.*—Influence lines for shear are given in Fig. 28. The curve $A''\,B'\,C'$ is the influence line for R_1, and the curve $A'\,D'''\,B''$ is drawn a unit distance below. The complete influence line for any point D is then given by the curves $A'\,D'''$ and $D''\,B'\,C'$. The construction shows clearly the position of moving loads for maximum values.

22. *Maximum Moments and Shears Due to Fixed and Moving Uniform Loads.*—Fig. 29 shows graphically the greatest positive and negative moments at all sections of a continuous girder of two equal spans, due to dead and live loads, considered as uniform loads. The numerical ordinates are the coefficients of $p\,l^2$. The dead-load curve

is the same as given in Fig. 24. The positive live-load moments for all sections, excepting those that are nearer the centre than 0.8 l, are given by loading one span fully, as shown in Art. 19, and Fig. 27 (*b*). For sections near the centre a partial load gives the maximum positive moment as shown in Fig. 27 (*c*). For maximum negative moment at all sections to the left the 0.8 point, the second span only is loaded (Fig. 27 (*b*)); for sections near the centre a portion of the beam at the left end is also loaded (Fig. 27 (*c*)). For point B the entire span is loaded. If the partial loadings for sections near the centre are neglected,

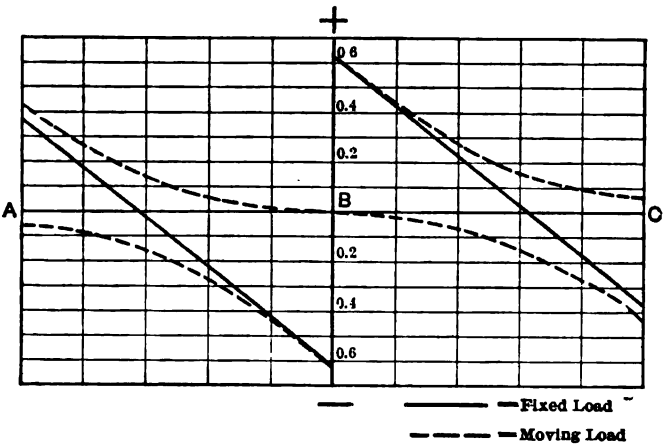

FIG. 30.—Shears in a Two-Span Continuous Girder.

either one or both spans being fully loaded, the resulting curves will be as shown by the dotted lines in Fig. 29.

Fig. 30 shows the maximum shears at all sections due to a fixed and a moving uniform load, the values being coefficients of $p\,l$.

23. Continuous Girder of Two Spans, Spans Unequal.—If the span lengths are unequal the calculations of reactions, moments, and shears will be but slightly modified. The same general position of moving loads will be required for maximum values, but the point of inflection noted in Art. 20 will be shifted somewhat.

24. Continuous Girder of Three Spans.—*Uniform Load on All Spans.*—Assume a girder having equal end spans, but a centre span of any length, Fig. 31. Let l = length of end spans and $n\,l$ = length

of centre span. This type of girder is often used in swing-bridge construction and is occasionally met with elsewhere.

For a uniform load extending over the entire girder of p per unit length we have, from eq. (9), for spans 1 and 2, noting that $M_3 = M_2$,

$$2 M_2 (l + n l) + M_2 n l = - \tfrac{1}{4} p l^3 - \tfrac{1}{4} p n^3 l^3, \quad . \quad (27)$$

whence

$$M_2 = M_3 = - \frac{\tfrac{1}{4} p l^2 (1 + n^3)}{2 + 3 n}. \quad . \quad . \quad . \quad . \quad . \quad (28)$$

From this is readily derived,

$$R_1 = R_4 = \frac{p l}{4} \left[\frac{3 + 6 n - n^3}{2 + 3 n} \right], \quad . \quad . \quad . \quad . \quad . \quad (29)$$

$$R_2 = R_3 = \frac{p l}{4} \left[\frac{5 + 10 n + 6 n^2 + n^3}{2 + 3 n} \right]. \quad . \quad . \quad . \quad (30)$$

The moments and shears are found at intermediate points as ex-

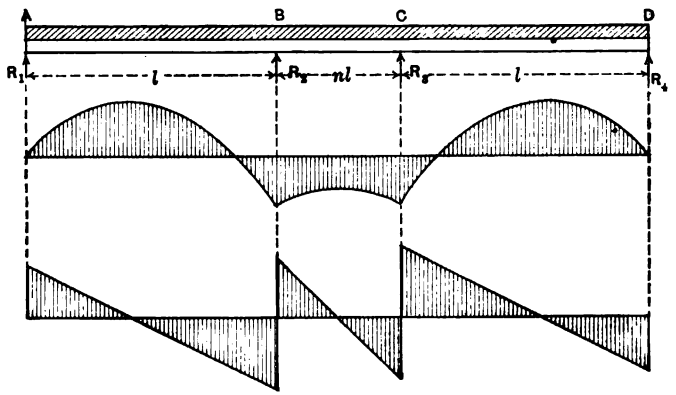

FIG. 31.

plained before. Fig. 31 represents the variation in moments and shears throughout the girder.

25. *Single Load on First Span.* (Fig. 32.) A load P is placed a distance $k l$ from A. Substituting in eq. (8) for spans 1 and 2 we have

$$2 M_2 (l + n l) + M_3 n l = - P l^2 (k - k^3), \quad . \quad . \quad (a)$$

and again for spans 2 and 3

$$M_2 n l + 2 M_3 (n l + l) = 0. \quad . \quad . \quad . \quad . \quad (b)$$

From these we derive

$$M_2 = -\frac{2+2n}{N} P l (k - k^3). \quad . \quad . \quad . \quad . \quad . \quad (31)$$

$$M_3 = \frac{n}{N} P l (k - k^3), \quad . \quad . \quad . \quad . \quad . \quad . \quad . \quad (32)$$

in which $N = 4 + 8n + 3n^2$.

Thence the reactions are

$$\left.\begin{aligned} R_1 &= P(1 - k) - \frac{2+2n}{N} P (k - k^3), \\ R_2 &= P k + \frac{2 + 5n + 2n^2}{nN} P (k - k^3), \\ R_3 &= -\frac{2 + 3n + n^2}{nN} P (k - k^3), \\ R_4 &= \frac{n}{N} P (k - k^3). \end{aligned}\right\} \quad . \quad . \quad . \quad (33)$$

In a similar manner the moments and reactions for a single load on the second span may be found. The variation in moments and shears

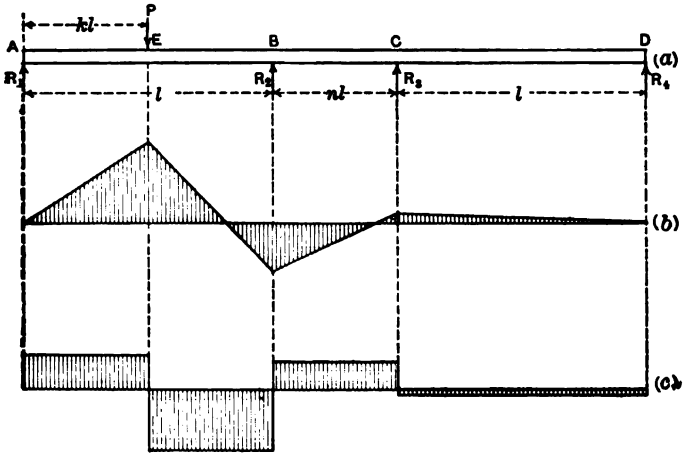

FIG. 32.

for a single load in the first span is shown in Fig. 32. It will be noted that there is a point of inflection in both the first and second spans showing, as in Art. 20, that for certain distances near the centre supports

the moments may be either positive or negative, depending upon the position of the load.

26. *Influence Lines for Moments and Shears.*—In Fig. 33 are shown the influence lines for moments at the centre point E of the first span, ($k = \frac{1}{2}$), the point F ($k = 0.9$), and the centre point G of the second span. The length of span $B\,C$ is taken at one-half of $A\,B$ ($n = \frac{1}{2}$).

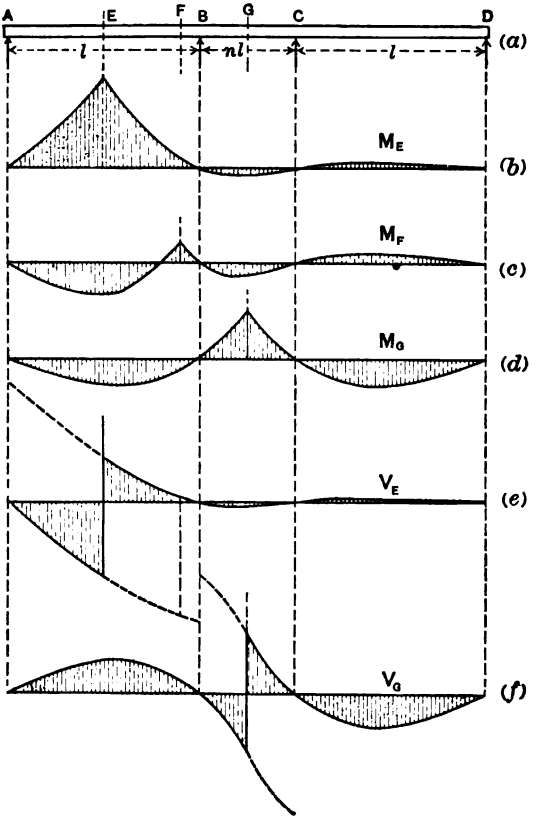

FIG. 33.

The influence lines for shears at E and G are also given. These figures show clearly the relative effect of loads on the several spans and particularly the small effect of loads in the third span upon the stresses in the first span. The influence line for M_F brings out the same conditions as to loading as shown in Fig. 27 for the two-span girder.

27. Maximum Moments and Shears in a Continuous Girder of Three Equal Spans.—Fig. 34 gives graphically the moments due to a fixed uniform load, and the maximum positive and negative moments

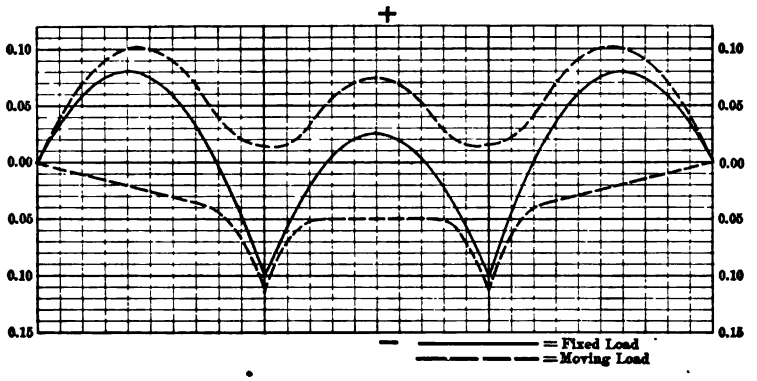

FIG. 34.—Moments in a Three-Span Continuous Girder.

due to a moving uniform load, the ordinates being the coefficients of $p\,l^2$, where p = load per unit length.

Fig. 35 gives the maximum shears for the same kind of loading. It is to be noted that the shears do not vary greatly from those in a simple span, the maximum being 0.6 $p\,l$ for fixed load and 0.62 $p\,l$ for moving load.

28. Continuous Girders of Several Spans.—It is seldom that a

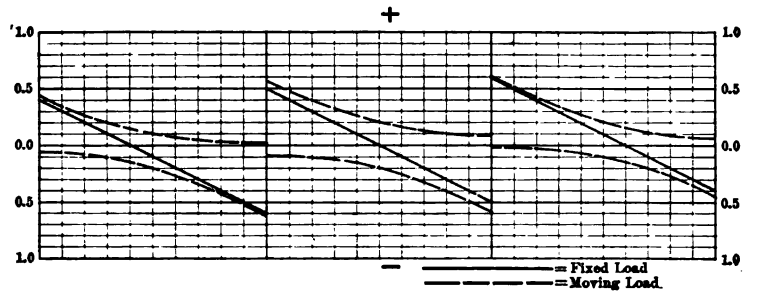

FIG. 35.—Shears in a Three-Span Continuous Girder.

continuous girder of more than three spans is employed for bridges, but in modern building construction, especially where reinforced concrete is used, continuous beams of numerous spans frequently occur.

While an exact solution of such cases is seldom necessary, it is important to know the possible maximum stresses which may be caused by moving loads. The determination of moments is of more importance in this

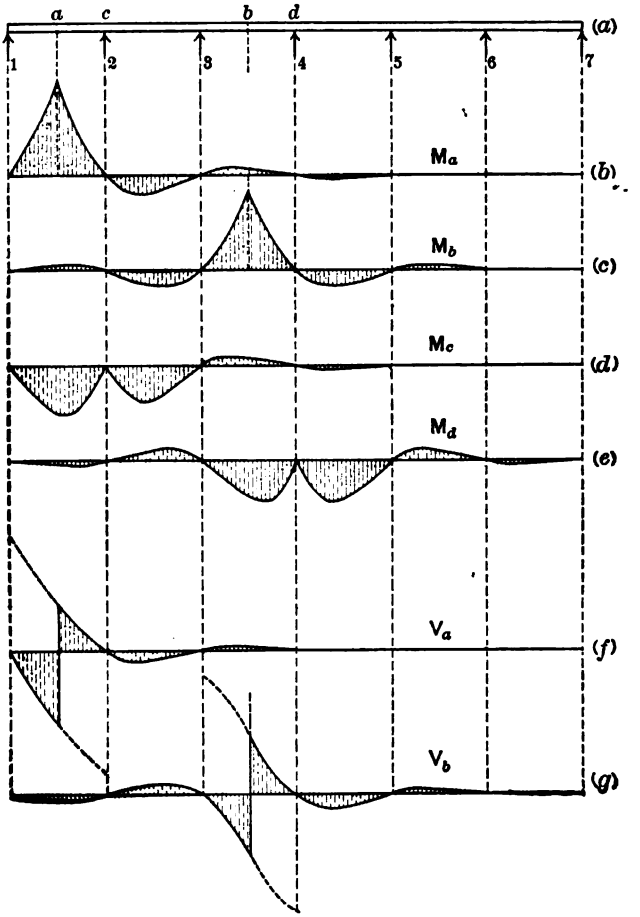

FIG. 36.

case than that of shears, as the shears do not differ greatly from those in simple beams.

29. *Influence Lines for Moments and Shears.*—Assume a girder of six equal spans. To illustrate the effect of loads on various spans

upon the bending moments, influence lines have been drawn in Fig. 36 for moments at the centres of spans 1–2 and 3–4, and at supports 2 and 4. A maximum moment at the centre of a span requires each alternate span to be loaded, and a maximum moment at the support requires the two adjacent spans to be loaded and then each alternate span. The small effect of loads on remote spans is to be noted.

Fig. 36, (*f*) and (*g*), shows influence lines for shears in spans 1–2 and 3–4. The general rule of loads in alternate spans is seen to hold true as for moments, but the effect of remote loads upon maximum shears is relatively less than in the case of moments.

30. *Maximum Moments for Uniform Fixed and Moving Loads.*— To assist in estimating the probable maximum moments due to uniform loads, calculations have been made of the maximum moments at supports and at centres of spans, for continuous girders of from two to seven equal spans, and the results are given in the following table.

COEFFICIENTS OF $p l^2$, FOR MAXIMUM MOMENTS IN CONTINUOUS GIRDERS FOR UNIFORM FIXED AND MOVING LOADS.

No. of Spans.	Intermediate Spans and Supports.				End Span and Second Support.			
	At Centre of Span. (+)		At Support. (−)		At Centre of Span. (+)		At Support. (−)	
	Fixed.	Moving.	Fixed.	Moving.	Fixed.	Moving.	Fixed.	Moving.
Two	.....	.....	.....	.....	.070	.095	.125	.125
Three	.025	.075	.....	.....	.080	.100	.100	.117
Four	.036	.081	.071	.107	.071	.098	.107	.120
Five	.046	.086	.079	.111	.072	.099	.105	.120
Six	.043	.084	.086	.116	.072	.099	.106	.120
Seven	.044	.084	.085	.114	.072	.099	.106	.120

It is found in general that for all spans, excepting the end span and the adjoining support, the maximum positive and negative moments do not vary greatly in the several spans. For the end spans and adjacent supports the maximum are considerably higher. The results are, accordingly, arranged in two groups in the table. For the intermediate spans the greatest value for the several spans is given in each case. The quantities are the coefficients of $p l^2$. It is to be noted

that for girders of five or more spans the maximum moments are but little affected by the number of spans.

31. Continuous Girders with Variable Moment of Inertia.—If the moment of inertia varies, then in the expression for deflection, eq. (5), Art. 3, the quantity I must be left under the integral sign. It is then possible, as in Art. 11, to develop a relation between three consecutive moments and the loads in the two included spans, in which the various integrals containing I are solved by substituting in detail the values of this quantity. It is unnecessary, however, to derive such general formulas, as the cases arising in practice can more readily be solved by direct methods.

32. *Reactions for a Two-Span Continuous Girder with Variable Moment of Inertia.*—It will be convenient to derive at once the formula for one of the reactions, as R_1, for any load P on one span (Fig. 37).

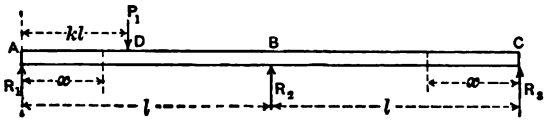

FIG. 37.

This may be done by the application of the theory of deflection or of redundant members, explained in Part I, Chapter VII. Considering the reaction R_1 as the redundant force, the conditions require that the total effect of this reaction, and of all other forces (P, R_2, and R_3), must be such as to cause zero deflection at A.

If M = bending moment at any section due to all the given forces, and m = bending moment due to a reaction $R_1 = 1$, then, as in Art. 222, Part I, for zero deflection at A,

$$\int_A^C \frac{M\,dx}{EI} \cdot m = 0. \quad . \quad . \quad . \quad . \quad . \quad . \quad (34)$$

As in the case of redundant members, the moment M may be considered in two parts: a part M' due to the given loads, with the support at A removed, and a part M'' due to R_1. Then we have $M'' = R_1 \times m$, and hence

$$\int_A^C \frac{M\,dx}{EI} \cdot m = \int_A^C \frac{M'\,m\,dx}{EI} + R_1 \int_A^C \frac{m^2\,dx}{EI} = 0. \quad . \quad (35)$$

From which (E being assumed constant),

$$R_1 = -\frac{\int_A^C \frac{M' m\, dx}{I}}{\int_A^C \frac{m^2\, dx}{I}}. \quad . \quad . \quad . \quad . \quad . \quad (36)$$

This expression is general for spans of any length and for any value of I.

To illustrate the use of eq. (36) consider the case of two equal spans. It will be necessary to perform some of the integrations indicated in three parts, namely, from A to D, D to B, and B to C. The values of M' and m for these sections are as follows:

Section	M'	m	$M'm$
A to D	0	x	0
D to B	$-P(x-kl)$	x	$-P(x^2-klx)$
B to C (origin at C)	$-P(1-k)x$	x	$-P(1-k)x^2$

Therefore

$$\int_A^C \frac{M' m\, dx}{I} = -P\int_{kl}^{l} \frac{(x^2 - klx)\, dx}{I} - P(1-k)\int_0^l \frac{x^2\, dx}{I},$$

and $\int_A^C \frac{m^2\, dx}{I} = 2\int_0^l \frac{x^2\, dx}{I}$; whence from (36),

$$R_1 = \frac{P}{2}\left[(1-k) + \frac{\int_{kl}^{l} \frac{(x^2 - klx)\, dx}{I}}{\int_0^l \frac{x^2\, dx}{I}}\right]. \quad . \quad . \quad (37)$$

For constant I, eq. (37) reduces to the value given in eq. (25). Note that in eq. (36) the numerator is the deflection of A for load P, the support being removed, and the denominator is the deflection of this point for a load unity acting at A. In applying eq. (37) the values of I would be taken as constant for short lengths along the girder and the integration performed in parts (or as a summation).

For a girder of three spans the redundant reactions are two in number and the two desired equations are obtained by placing equal to zero the deflections at two supports and expressing all moments M' in terms of the loads, with the two redundant reactions being removed, exactly as in the solution of two redundant members. For an example, see Art. 77.

33. EXAMPLE.—*Plate girder with variable Moment of Inertia.* Assume the following data: two equal spans of 60 ft.; dead load = 1,200 lbs. per ft. per girder; live load, including impact, =9,600 lbs. per ft. per girder. The moments will first be calculated on the assumption of uniform moment of inertia, using the result of Art. 22. The maximum dead- and live-load moments are given in Fig. 38, and the total maximum, irrespective of sign, by the upper full line.

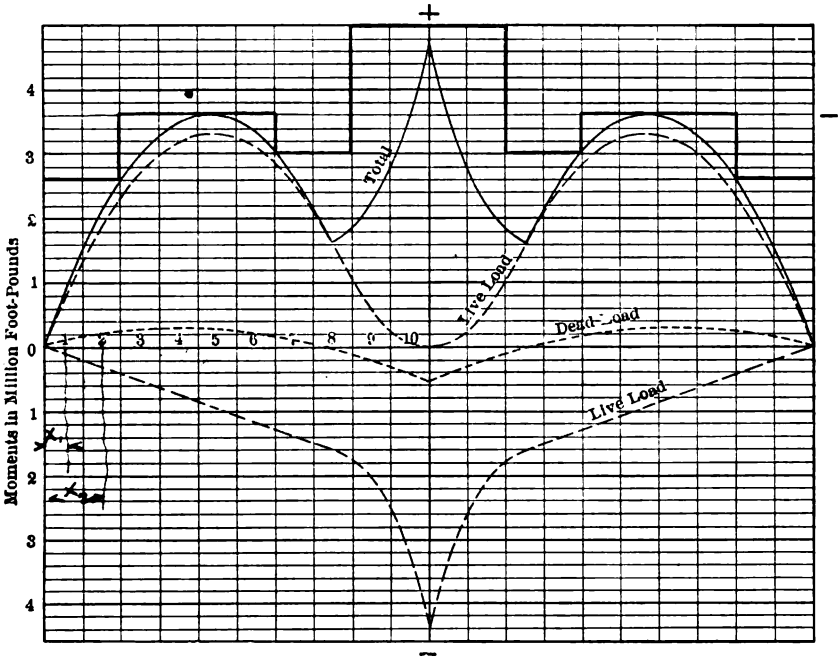

FIG. 38.

Suppose, now, the moments of inertia of the girder be made to fit this maximum curve in the manner shown by the heavy stepped line, varying the flanges in four sections.

We will now proceed to calculate the true reactions for a uniform load of one pound per foot over the entire structure. For this purpose each span will be divided into ten sections as numbered, and the integrations of eq. (36) performed as summations. Let R_2 be assumed as the redundant force. Then M' of eq. (36) will be the bending moment at any section in the 120-ft. girder under the load of one pound per foot and with R_2 removed; m will be the moment due to a one-pound load at the centre of the 120-ft. span. For the purpose of this calculation the values of I need be known only relatively. The I for sections 1 and 2 will therefore be called unity, that for sections 3–6 will be 1.38, for 7 and 8, 1.15, and for 9 and 10, 1.92. The value of $d\,x = 6$ ft. The complete calculations are as follows:

$M' = R_1 x - \frac{w x^2}{2}$ $\quad m = R_1 x$

$R_1 = 60$

$x = 3$

$w = 1$

$x_2 = x_1 + 6$

Section.	I	$\frac{dx}{I}$	M'	m	$\frac{M' m dx}{I}$	$\frac{m^2 dx}{I}$
1.....	1.0	6.0	175	1.5	1,600	13
2.....	1.0	6.0	499	4.5	13,500	121
3.....	1.38	4.33	787	7.5	25,600	244
4.....	1.38	4.33	1,039	10.5	47,300	478
5.....	1.38	4.33	1,255	13.5	73,500	789
6.....	1.38	4.33	1,435	16.5	102,700	1,179
7.....	1.15	5.20	1,580	19.5	160,200	1,977
8.....	1.15	5.20	1,687	22.5	197,400	2,632
9.....	1.92	3.12	1,760	25.5	140,000	2,030
10.....	1.92	3.12	1,795	28.5	156,200	2,530
				Σ	918,000	11,993

$$R_2 = \frac{918{,}000}{11{,}993} = 76.4;\ R_1 = 60 - 76.4/2 = 21.8.$$

The value of R_2 for uniform moment of inertia is $5/4 \times 60 = 75.0$. The true bending moment at the centre for unit load $= 21.8 \times 60 - 60 \times 30 = -492$, whereas, for uniform I the value of $M_2 = -\frac{1}{8} P l^2 = -440$, a difference of about 10%. The maximum positive moment for $x = \frac{3}{8} l$ is $21.8 \times 22.5 - \frac{22.5^2}{2} = 237$, while for uniform I this moment $= 253$, a difference of about 2%.

The effect of a settlement of support will be also determined. If the girder is 8 ft. deep its moment of inertia will be about 200,000 in^4. The centre deflection for a concentrated load of 1,000 lbs. is given by the formula $\frac{1}{48} \frac{P l^3}{E I}$ and amounts to .00104 in. A settlement of the centre support of .001 in. would therefore decrease the centre reaction by 1,000 lbs.; a settlement of 0.4 in. would decrease it by 400,000 lbs., which is one-half the total dead and live load reaction.

34. The Analysis of Continuous Trusses.—The methods of analysis of this chapter have been based on the theory of the deflection of solid beams, in which the effect of shearing distortion is so small compared with that from flexural stresses as to be negligible. In the analysis of trusses the same formulas are generally applied, but in this case the errors due to shearing strains (web strains) are much greater and in many cases are too large to be neglected. Then, again, if the formulas for constant I be employed still further errors are introduced in case the moment of inertia is made variable. The usual formulas must there-

fore be considered as only roughly approximate and suitable only for a preliminary design. Such a design being made, an exact solution may be worked out by the principle of deflections, in a manner similar to that explained in Art. 32. The analysis of two- and three-span trusses is considered in detail in the next chapter.

35. The Moment of Inertia of a Truss. In applying to a truss various formulas derived from solid beams it becomes necessary to determine the value of the moment of inertia, or its equivalent, for the truss. This equivalent is found by considering the chord members only, as the bending moments concerned are fully resisted by the chord members. The web members offer no aid in resisting these moments, and hence they do not strengthen the truss against bending moment as here considered. In getting the moment of inertia for purposes of calculating reactions, etc., the gross-sections of the chords should be taken, as the stiffness of the structure is under consideration and this depends on gross rather than net sections. Due allowance should be made for long splice plates. If the two chords differ much in cross-section the centre of gravity of the two opposite segments may be found and the correct value of I determined with respect to this centre of gravity. The effect of web members is not to make the truss more rigid by adding to its moment of inertia, but less rigid by reason of the distortion due to shear or web stresses as noted in Art. 8. Variable moment of inertia can be taken account of by using corresponding formulas developed from the solid beam, but web distortion can be taken account of only by the method of deflection as explained later (Art. 63).

36. Use of Continuous Girders.—Continuous girders are now very rarely built excepting in the form of swing bridges, a type fully discussed in the next chapter. Compared with a series of simple spans a continuous girder shows some saving in material, as the average bending moment is less. The shears are, however, about the same. Thus, in the two-span girder, Fig. 29, the total positive moment area for one span, for fixed load, is $\int_0^{\frac{4}{7}l} (R_1 x - \frac{1}{2} p x^2)\, dx = \frac{9}{256} p l^3$, and the negative moment area $= \int_{\frac{4}{7}l}^{l} (R_1 x - \frac{1}{2} p x^2)\, dx = \frac{11}{768} p l^3$. The total area, neglecting sign, $= \frac{19}{384} p l^3$. For a simple span the moment area $= \frac{1}{12} p l^3$.

The total moment area for the continuous girder is therefore only 60% of that of the simple span. This represents approximately the relative chord sections required for a fixed load.

For moving loads the average moments are nearly as great in the continuous girder as in the simple span. In the two-span girder the average maximum live load moment = .070 $p\,l^2$ while for the simple span it is .083 $p\,l^2$. Considering the reversal of stress which occurs in the continuous girder and which calls for additional material, the saving is very little or nothing.

For the three-span girder the saving will be somewhat less in the end spans, but more in the centre span, than in the case of the two-span girder.

It will be seen from the foregoing that the economy of the continuous girder may well be considered where the fixed loads are relatively large. The continuous girder possesses also an advantage in the fact that it may be erected conveniently without the use of false work by building out from the portion already in place. This form of construction has, however, serious disadvantages which generally outweigh its advantages. Chief of these is the effect upon the stresses of a slight settlement of supports, or a variation of temperature among the different members of the structure. Convenience of erection, as well as economy of material in certain cases, is substantially secured by the cantilever bridge (Chapter III), which is constructed as a continuous structure, but is afterward modified so that hinged joints are introduced at suitable places, thus breaking up the continuous structure into a series of simple trusses. The stresses in the structure are then no longer affected by unequal settlement of supports.

CHAPTER II

SWING BRIDGES

SECTION I.—GENERAL CONSIDERATIONS

37. General Arrangement.—Swing bridges are built as continuous girders or trusses, arranged to turn on a centre pier. When closed, they are supported to a greater or less extent at the two ends, but designs differ considerably in the arrangement of details, both at the centre pier and at the end supports.

38. Arrangements at Centre Support.—With respect to the centre support there are two general arrangements, the *centre-bearing* and the *rim-bearing* structure. In the first, the entire weight of the bridge, when open, is carried by a centre pivot P (Fig. 1), the weight of the

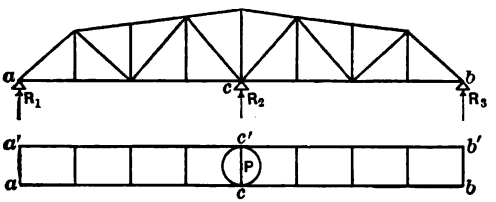

FIG. 1.

two trusses being transferred thereto by a cross-beam or beams, $e\ e'$. The centre bearing at P may consist of a pivot or a nest of conical rollers. In either case the bridge is known as a *centre-bearing* bridge. When the structure is open it is prevented from tipping on the pivot by means of a few guide or balance wheels, attached to the frame of the structure and bearing on a circular track placed on the pivot pier. These wheels are not intended to carry any considerable load and are neglected in the calculations of the stresses in the main trusses or girders. When the bridge is closed, wedges are generally inserted at c and c' in such a manner as to support the trusses or girders directly, and so relieve the pivot of most or all of the weight of the live load.

In the rim-bearing structure the trusses or girders are supported by a large circular girder or drum, which, in turn, rests and turns upon a series of closely spaced rollers moving on a circular track below. Fig. 2 illustrates this type of turn-table, and four methods of transferring the load from the trusses to the drum. In (*b*) the load is transferred to the drum at four points, while in (*c*) it is transferred at 8 points by the aid of the short beams, *e f*, *g h*, etc. In either case the supports of each truss at the centre pier are two in number, *c* and *d*, *c'* and *d'*. The panel or span *c d* is equal to the width, centre to centre

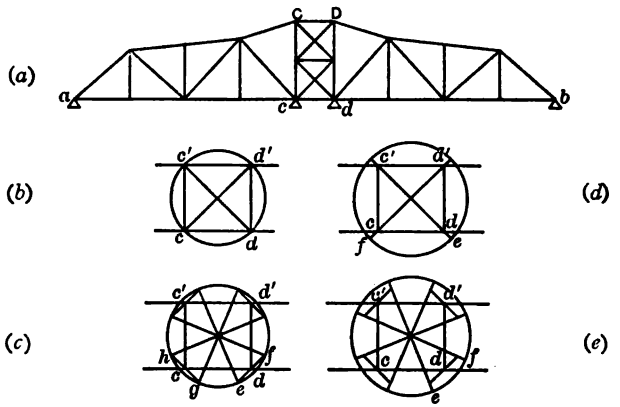

FIG. 2.

of trusses, and may or may not be equal in length to the other panels of the structure. The arrangement here described is known as a *rim-bearing* turn-table.

In the rim-bearing structure it is necessary to place a pivot at the centre to guide the structure when in motion and to resist the action of the wind, but in the forms shown in Figs. 2 (*b*) and (*c*) this pivot carries no vertical load. On some accounts it is advantageous to transfer a part of the load to this pivot. This may be done to any desired extent by the use of radial girders, as shown in Figs. (*d*) and (*e*), upon which the truss is supported. This arrangement is known as part rim and part centre bearing, but as regards the trusses the supports are at *c*, *d*, *c'*, and *d'*, exactly as in Figs. (*b*) and (*c*). In either case, therefore, the main girder or truss is to be considered as having four supports.

39. Arrangements of End Supports.—The arrangement of end supports must be such that when ready to turn the bridge will be free and clear from its bearings. When closed and ready for traffic the ends may (1) be left free, or (2) be latched down to prevent hammering, or (3) be raised by wedges or other mechanical device so that some of the dead load is carried by the end support. For ordinary highway bridges the first method is often used, but for railway structures, and preferably in all cases, either the second or third arrangement is employed in order to prevent hammering at the ends and to secure a better continuity of roadway. The third method is the one generally used. The various details of these arrangements are discussed in Part III, but their effect upon stress calculations is fully explained in the following articles.

40. Application of Continuous Girder Formulas in Stress Calculations.—In the analysis of swing bridges the formulas derived in the preceding chapter are, to a greater or less degree, applicable. When the structure is closed and the ends held in place, either by latching down or by raising sufficiently to prevent them from lifting, any live load coming upon the structure affects all the reactions; that is to say, the bridge, under live load, acts as a continuous structure over three or four supports, as the case may be. The resulting reactions must be determined on this basis and in their calculations use is made of the formulas of Chapter I. Generally the formulas for solid beams of constant moment of inertia are used for all cases, whether the structure is a plate girder or a truss bridge. The results are therefore only approximate but are usually sufficiently accurate for all practical purposes. After the design is completed more exact values of the stresses can be determined, if desired, by the use of the methods already mentioned in Art. 34. These methods will be illustrated in the following articles and the errors of the usual approximate method will be determined in certain cases.

41. Loads.—*The dead load* for railway swing bridges is approximately equal to the weight of a fixed span of the same length, less the weight of the turn-table, or the portion supported directly by the center pier.

The Live Load.—In the case of continuous bridges the inaccuracies in the calculations, due to approximations in assumptions and to tem-

perature effects, are very considerable, so that the refinements of the wheel-load method of analysis are quite unwarranted. The use of an equivalent uniform load is to be preferred, the amount of which may be selected by a consideration of the forms of the influence lines, as explained later. If the wheel-load method of calculation is preferred, the use of influence lines is the most convenient method of procedure. This is illustrated in Art. 57.

SECTION II.—THE CENTRE-BEARING SWING BRIDGE

42. Formulas for Reactions.—Applying the theorem of three moments, as in Art. 20, we derive the following values for the reactions, for a single load P on the first span:

$$R_1 = -\frac{P l_1}{2 (l_1 + l_2)} (k - k^3) + P (1 - k), \quad . \quad . \quad . \quad (1)$$

$$R_3 = -\frac{P l_1}{2 (l_1 + l_2)} (k - k^3), \quad . \quad . \quad . \quad . \quad . \quad . \quad . \quad (2)$$

$$R_2 = P - R_1 - R_3. \quad . \quad . \quad . \quad . \quad . \quad . \quad . \quad . \quad . \quad (3)$$

For equal spans

$$R_1 = \frac{P}{4} (4 - 5 k + k^3), \quad . \quad . \quad . \quad . \quad . \quad . \quad . \quad . \quad (4)$$

$$R_2 = \frac{P}{2} (3 k - k^3), \quad . \quad . \quad . \quad . \quad . \quad . \quad . \quad . \quad . \quad (5)$$

$$R_3 = -\frac{P}{4} (k - k^3). \quad . \quad . \quad . \quad . \quad . \quad . \quad . \quad . \quad . \quad (6)$$

To assist in the calculations, values of R_1 and R_3 are given in the following table, for P = 1,000 lbs., for various values of k, for trusses of equal spans and for various numbers of equal panels from two to ten in each span. For R_2 use the relation $R_1 + R_2 + R_3 = P$. The table may also be readily used for girders by dividing the span into a convenient number of equal divisions, such as 8 or 10, and treating the points of division as load points. From this table the total reactions for any series of joint loads or concentrations can readily be obtained.

TABLE No. 2

CONSTANTS FOR REACTIONS, P = 1,000 POUNDS, FOR BEAM CONTINUOUS OVER THREE SUPPORTS, WITH TWO EQUAL SPANS

(For loads on the left span only.)

No. of Equal Panels in Each Span.	Values of k.	R_1 +	R_2 −
2.....	1 ÷ 2	+ 406.25	− 93.75
3.....	1 ÷ 3	592.6	74.1
	2 "	240.7	92.6
		$\Sigma R_1 = +$ 833.3	$\Sigma R_2 = -$ 166.7
4.....	1 ÷ 4	691.4	58.6
	2 "	406.3	93.8
	3 "	168.0	82.0
		$\Sigma R_1 = +$ 1265.7	$\Sigma R_2 = -$ 234.4
5.....	1 ÷ 5	752.0	48.0
	2 "	516.0	84.0
	3 "	304.0	96.0
	4 "	128.0	72.0
		$\Sigma R_1 = +$ 1700.0	$\Sigma R_2 = -$ 300.0
6.....	1 ÷ 6	792.8	40.5
	2 "	592.6	74.1
	3 "	406.25	93.75
	4 "	240.75	92.60
	5 "	103.0	63.70
		$\Sigma R_1 = +$ 2135.4	$\Sigma R_2 = -$ 364.65
7.....	1 ÷ 7	822.2	35.0
	2 "	648.7	65.6
	3 "	484.0	87.5
	4 "	332.4	96.2
	5 "	198.2	87.5
	6 "	86.0	56.9
		$\Sigma R_1 = +$ 2571.5	$R \Sigma_2 = -$ 428.7
8.....	1 ÷ 8	844.3	30.5
	2 "	691.4	58.6
	3 "	544.5	80.6
	4 "	406.3	93.8
	5 "	279.8	95.2
	6 "	168.0	82.0
	7 "	73.7	51.3
		$\Sigma R_1 = +$ 3008.0	$\Sigma R_2 = -$ 492.3

TABLE No. 2—(*Continued*)

No. of Equal Pannels in Each Span.	Values of k.	R_1 +	R_2 −
9.....	1 ÷ 9	861.5	27.5
	2 "	725.0	52.8
	3 "	592.6	74.1
	4 "	466.4	89.2
	5 "	348.4	96.0
	6 "	240.7	92.6
	7 "	145.4	76.8
	8 "	64.5	46.7
		$\Sigma R_1 = +$ 3444.5	$\Sigma R_2 = -$ 555.7
10.....	1 ÷ 10	875.25	24.75
	2 "	752.0	48.0
	3 "	631.75	68.25
	4 "	516.0	84.0
	5 "	406.25	93.75
	6 "	304.0	96.0
	7 "	210.75	89.25
	8 "	128.0	72.0
	9 "	57.25	42.75
		$\Sigma R_1 = +$ 3881.25	$\Sigma R_2 = -$ 618.75

43. End Conditions Assumed in Calculating Stresses.—Where the customary practice is followed of raising the ends after closing, so as to cause some dead-load reaction, the amount of this uplift is usually determined on the basis that it shall be sufficient to prevent hammering, or what amounts to the same thing, that the end reaction shall never become negative under partial live load. This requires the temperature variations to be considered as well as the deflections, questions which are discussed in Art. 65. The net result is that the ends are usually lifted an amount which, under uniform temperature conditions, will develop dead-load reactions of from one-half to two-thirds of what they would be on the assumption of normal continuous-girder action with level supports. Temperature differences among the various members of the truss will then cause considerable variations in reactions, and to provide for this in the design it is generally assumed that the reactions under dead load may vary anywhere between zero and a value equal to that determined on the assumption of continuous-girder action.

In calculating dead-load stresses, therefore, two cases are considered: Case I, bridge open, or bridge closed and ends just touching, and acting as a double cantilever; and Case II, bridge closed and ends raised, bridge acting as a continuous girder. The stresses resulting from either case are then to be combined with the live-load stresses to give maximum results.

In calculating live-load stresses, the conditions giving rise to maximum or minimum total stress should be kept in mind. In getting positive live-load moments and positive shears (considering the first or left-hand span), it is to be noted that the corresponding dead-load values of positive sign are a maximum with maximum uplift. For this case the structure is then to be assumed as lifted at the ends a maximum amount, and therefore as acting as a continuous girder under live load. For live-load negative moments and shears a minimum uplift is the most unfavorable condition and therefore for these calculations the bridge is generally assumed as just touching the supports under dead load. This being the case, when the live load extends over one arm only, the other arm is free or just touching, and the live-load stresses in the first arm are calculated as for a simple span. When both arms are loaded the ends come to a bearing and the structure is again a continuous girder so far as the live loads are concerned. In either case the dead-load stresses are the same as for bridge swinging free, or Case I. Considering the position of live loads producing maximum positive and negative moments and shears, as shown by the influence lines of Art. 26, it will be found that the analysis may be separated into the following cases.

Case I.—Dead load, bridge swinging, cantilever action.

Case II.—Dead load, bridge closed and ends raised, continuous-girder action.

Case III.—Live load on first span for maximum positive moments and positive shears, bridge acting as a continuous girder.

Case IV.—Live load on both arms for negative moments and negative shears, both ends bearing, bridge acting as a continuous girder.

The maximum results under Case IV, as shown by the influence lines of Art. 26, will generally require loads to be applied on two separate parts of the structure, or the use of "broken loads." This may or may not be a reasonable assumption, depending upon the location of the

bridge. If broken loads are not to be considered then the negative shears, excepting for sections near the centre, will be a maximum with loads on one span only, which condition, with minimum dead-load uplift, will cause the opposite end to rise and the first span to act as a simple span. We then may include an additional case:

Case V.—Broken loads not considered. Live load on first span for negative shears, opposite end free, first span acting as a simple span.

For sections near the centre the maximum negative values will be caused by a fully loaded bridge, Case IV.

The maximum combined stresses are then found by combining Case II with Case III, and Case I with either Case IV or Case V.

If the ends are not raised but are simply latched down, the dead-load stresses are determined by Case I. These are then to be combined with those of either Case III or Case IV. In this case the effect of temperature variations should be separately allowed for.

44. Plate Girder Bridge of Two Equal Spans.—Assume the following data: l = 80 ft.; dead load = 1,200 lbs. per ft. per girder; live load = equivalent uniform for moment in an 80-ft. span for Cooper's *E*-60 loading, Fig. 3.

From Fig. 4 we find for this loading, and a span of 80 feet, an equivalent uniform load for the quarter point of 3,450 lbs. per foot, hence for *E*-60 the loading will be $3{,}450 \times 6/5 = 4{,}140$ lbs. per ft. per girder. Broken loads will be considered as possible. The loads will be assumed as concentrated at points 10 feet apart. The dead-load concentration will be 12,000 lbs., and the live-load concentration 41,400 lbs. The dead-load concentration at the end will be taken at 6,000 lbs., and the moments and shears will be determined for the first span. Fig. 5 (*a*) shows the load points in this span.

45. *Case I. Dead Load, Bridge Swinging, Cantilever Action.*—The calculation of moments and shears for this case requires no explanation. The results are shown by the curves marked *I* in Figs. 5 (*b*) and (*c*). In the curves of Fig. (*c*) the shears between consecutive load points are plotted as ordinates midway between loads and the points so found are connected by straight lines.

46. *Case II. Dead Load, Bridge Closed, Ends Raised, Continuous-girder Action.*—For this case the value of R_1 is readily determined from the table on p. 47, using the 8-panel span. The total value of R_1 for

Spacing	←8→	←5→	←5→	←5→	←9→	←5→	←6→	←5→	←8→	←8→	←5→	←5→	←5→	←9→	←5→	←6→	←5→	←10→	←10→	
No.	1	2	3	4	5	6	7	8	9	10	11	12	13	14	15	16	17	18	19	20
Σ Dist.	0	8	13	18	23	32	37	43	48	56	64	69	74	79	88	93	99	104	114	124
P	12.5	25	25	25	25	16.25	16.25	16.25	16.25	12.5	25	25	25	25	16.25	16.25	16.25	16.25	25	25
Σ P	12.5	37.5	62.5	87.5	112.5	128.75	145	161.25	177.5	190	215	240	265	290	306.25	322.5	338.75	355	380	405
M	0	100	287.5	600	1,087.5	2,050	2,693.75	3,563.75	4,870	5,700	7,310	8,385	9,585	10,910	13,520	15,051.25	16,986.25	18,680	22,280	26,080
M′ (P_1 omitted)	0	0	125	375	750	1,650	2,231.25	3,026.25	3,770	5,090	6,510	7,522.5	8,660	9,922.5	12,420	13,838.75	15,743.75	17,380	20,805	24,480
ΣP′ (P_1 omitted)	0	25	50	75	100	116.25	132.50	148.75	165.	177.5	202.5	227.5	252.5	277.5	293.75	310.0	326.25	342.5	367.5	392.5

Spacing	←10→	←10→	←10→	←10→	←10→	←10→	←10→	←10→	←10→	←10→	←10→	←10→	←10→	←10→	←10→	←10→	←10→	←10→	←10→	←10→
No.	21	22	23	24	25	26	27	28	29	30	31	32	33	34	35	36	37	38	39	40
Σ Dist.	134	144	154	164	174	184	194	204	214	224	234	244	254	264	274	284	294	304	314	324
P	25	25	25	25	25	25	25	25	25	25	25	25	25	25	25	25	25	25	25	25
Σ P	430	455	480	505	530	555	580	605	630	655	680	705	730	755	780	805	830	855	880	905
M	30,080	34,380	38,930	43,730	48,780	54,080	59,630	65,430	71,480	77,780	84,330	91,130	98,180	105,480	113,030	120,830	128,880	137,180	145,730	154,530
M′ (P_1 omitted)	28,405	32,580	37,005	41,680	46,605	51,780	57,205	62,880	68,805	74,980	81,405	88,080	95,005	102,180	109,605	117,280	125,205	133,380	141,805	150,480
ΣP′ (P_1 omitted)	417.5	442.5	467.5	492.5	517.5	542.5	567.5	592.5	617.5	642.5	667.5	692.5	717.5	742.5	767.5	792.5	817.5	842.5	867.5	892.5

FIG. 3.

a fully loaded bridge (1,000-pound joint loads) is + 3,008 − 492 = 2,516 lbs. Hence for Case II, $R_1 = 2{,}516 \times 12 = 30{,}200$ lbs. The moments at the several points are then found as for a single span. For point b, $M = 30{,}200 \times 10 = 302{,}000$ ft.-lbs.; for point c, $M = 30{,}200 \times 20 - 12{,}000 \times 10 = 484{,}000$ ft.-lbs., etc. The results are shown by curve *II*, Fig. 5 (*b*). The shear in section $a - b = R_1 = 30{,}200$ lbs.; shear in $b - c = 30{,}200 - 12{,}000 = 18{,}200$ lbs., etc. These shears are given by curve *II*, Fig. 5 (*c*).

47. *Case III. Live Load Positive Moments and Shears, Continuous-girder Action.*—In accordance with the principles explained in Art. 21, Chapter I, the first span is fully loaded for all moment centres excepting in the fifth part of the span next to the centre support. This part will include only the load point h. Hence for all other points the first span is fully loaded, and the second span is not loaded. It will be assumed that the ends are fully raised before the live load comes on, as this condition gives greatest positive or least negative dead-load moments and shears. The combination of live- and dead-load effects under these conditions will therefore give maximum values.

For first span fully loaded, Table 2, p. 47, gives $R_1 = 3{,}008 \times 41.4 = 124{,}500$ lbs. The moments are then found up to point g, inclusive, as in Case II, and are shown in Fig. 5 (*b*) by curve *III*. For point h some of the loads should be omitted, determined as follows: The position of a single load which will cause zero moment at h is found by substituting in the formula $\frac{x_o}{l} = \frac{4}{5 - k^2}$ (see Art. 20, eq. (26)). Here $\frac{x_o}{l} = 7/8$, whence k is found to be 0.65. Therefore, a load placed $0.65\,l$ from a will give zero moment at h; loads placed on the right of $0.65\,l$ will cause positive moments at h and loads placed on the left will cause negative moments. As the 0.65 point comes between f and g, then for maximum positive moment at h joints g and h should be loaded. Loading these joints, Table No. 2 gives $R_1 = (168 + 74) \times 41.4 = 10{,}000$ lbs. $M_h = 10{,}000 \times 70 - 41{,}400 \times 10 = 286{,}000$ ft.-lbs.

For the first span *fully loaded* the moment at h is 0, and that at i is negative. The dotted line *III a* in Fig. 5 (*b*) shows the moments arising from a fully loaded condition.

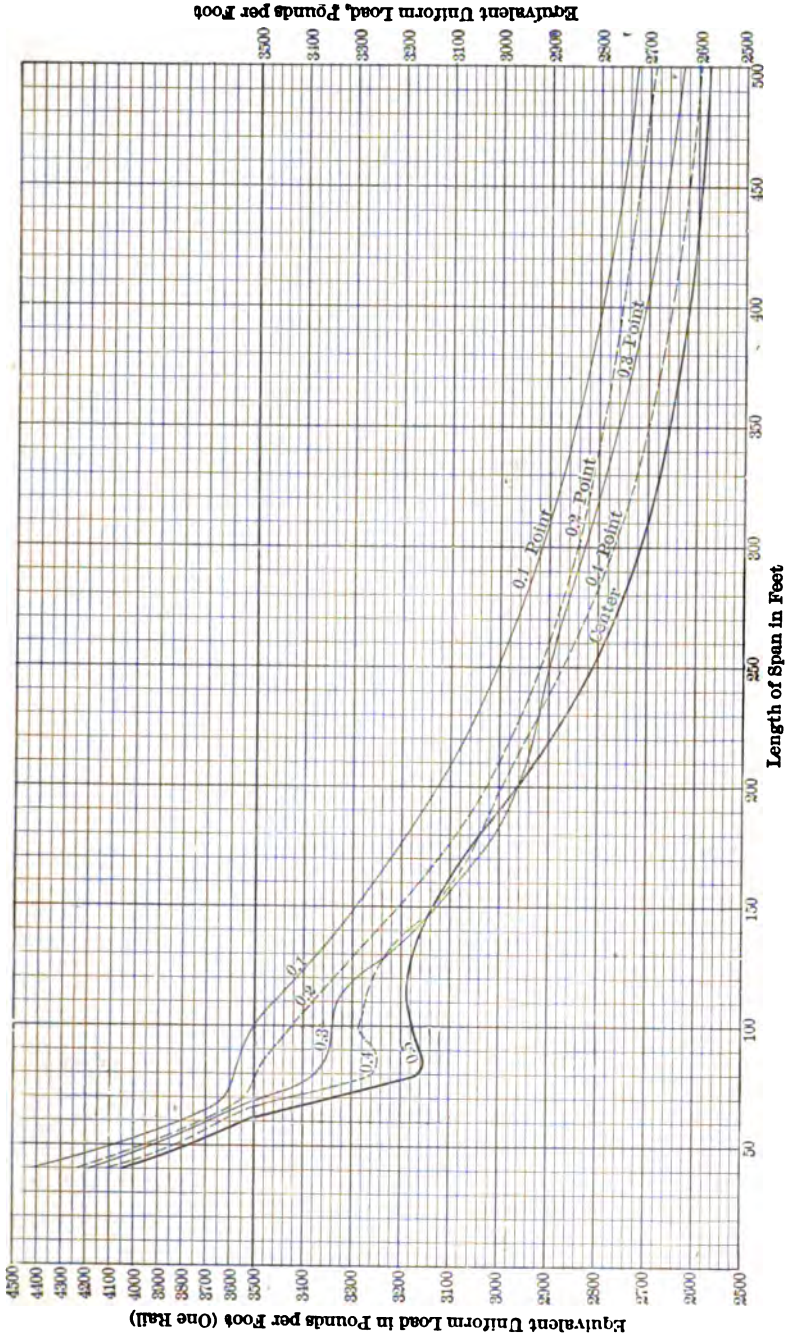
Equivalent Uniform Load in Pounds per Foot (One Rail)
Equivalent Uniform Load, Pounds per Foot
Length of Span in Feet
0.1 Point
0.2 Point
0.3 Point
Center
0.1
0.2
0.3
0.4
0.5

FIG. 4.

For maximum positive shears the first span is loaded from the section in question to the centre. The shear in section $a - b = R_1 =$ 124,500 lbs. For section $b - c$, load from c to h, inclusive. Table 3

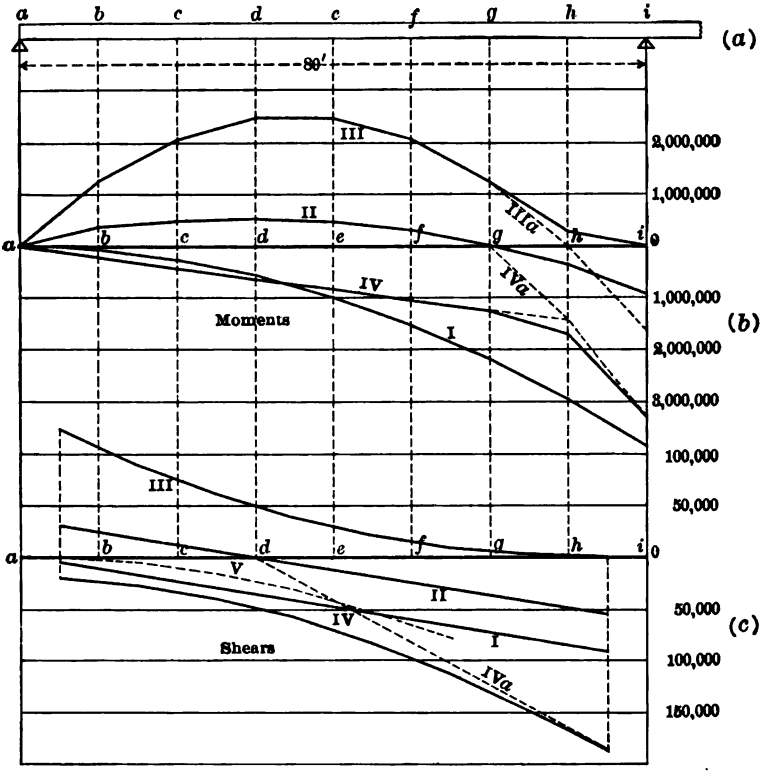

FIG. 5.—Dead and Live Load Moments and Shears.

gives $R_1 = (3{,}008 - 844) \times 41.4 = 89{,}500$ lbs. This is also the shear. The results are given in Fig. 5 (*c*), curve *III*.

48. *Case IV. Live Load Negative Moments and Shears, Continuous-girder Action.*—The maximum negative moments at all points except *h* will occur when the second span is fully loaded and the first span unloaded. Case I, dead load, will need to be combined with this case, but it is to be noted that for Case I the dead-load end reaction is zero. Hence a live load on the second span only will lift the end at *a* free

from the support and the girder will not act as a continuous structure. It is assumed, however, in this analysis, that the live load may be divided into two or more separate portions ("broken loads"), if necessary to produce maximum stresses. In this case, therefore, it will be assumed that the point *a* is also loaded, which will be sufficient to hold this end down. The second span will be fully loaded.

The reaction is given in Table 2 (under R_3) and is $-492 \times 41.4 = -20{,}400$ lbs. From this value the negative moments from *b* to *g* are determined. For point *h* it has already been shown under Case III that loads from *b* to *f* cause negative moments at *h*. Hence these points, in addition to the second span, should be loaded. The value of R_1 is $[3{,}008 - (168 + 74) - 492] \times 41.4 = 2{,}274 \times 41.4 = 94{,}200$ lbs., and $M_h = 94{,}200 \times 70 - 41{,}400 \times 5 \times 40 = -1{,}700{,}000$ ft.-lbs. For point *i* both spans are fully loaded and the value of *M* is $-3{,}280{,}900$ ft.-lbs. These moments are shown by curve *IV*.

The value of M_h, if loads from *b* to *f* are omitted, is equal to $-20{,}400 \times 70 = -1{,}428{,}000$ ft.-lbs. This is shown by the dotted extension of curve *IV*. For *both* spans fully loaded the moments at *g*, *h*, and *i* are shown by the dotted line *IV a*. The moment at *h* is the same as for second span only loaded.

The diagram illustrates clearly the fact that the moments at *h* are but slightly increased by the use of the broken loads, over the values determined for one or both spans fully loaded.

For negative shears the second span is fully loaded and the first span from the left end up to the section in question. The results are given in Fig. 5 (*c*), curve *IV*.

49. *Maximum Total Moments and Shears.*—Assuming that the dead-load stresses when the bridge is closed may be either those of Case I or Case II, these stresses are to be combined with the live-load moments and shears of both kinds to arrive at the maximum positive and negative values. The results are shown by the full lines in Fig. 6.

Fig. (*a*) shows that for the loads assumed, positive moments cannot exist at points nearer than 10 ft. from the centre; negative moments may occur at any point. Except for this distance of 10 ft. near the centre all flange stresses are therefore subject to reversal.

In the case of shears no positive shears are possible nearer than

about 30 feet from the centre; negative shears may occur at any point.

50. *Impact Allowance.*—In Fig. 6 the dead- and live-load moments and shears have been directly added, and the total stresses taken for

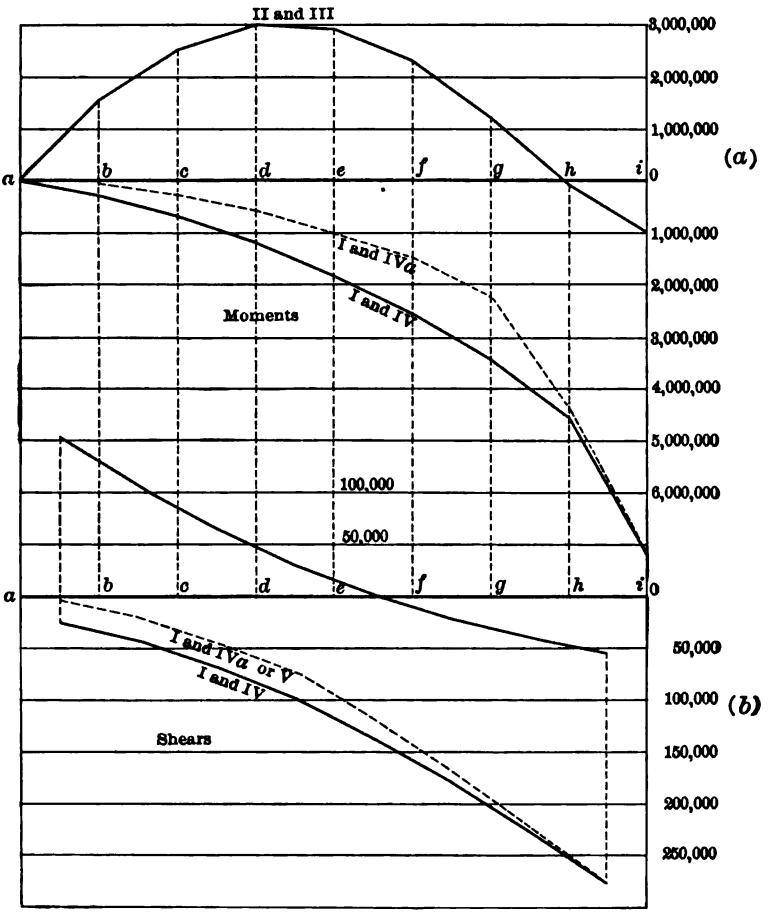

FIG. 6.—Maximum and Minimum Moments and Shears.

the maximum or minimum. Under most modern specifications, however, the live-load stresses would first be increased by a certain percentage to allow for impact, or dynamic effect, before being combined with the dead-load stresses. The amount of such allowance is dis-

cussed in Chapter VII. Whatever this may be, it would be applied directly to the results for live load given in Fig. 5 and then combined with the dead-load curves. The resulting curves would vary considerably from those given in Fig. 6 and would cross the axis at different points, thus affecting not only the maximum stresses but the range over which a reversal is possible.

51. *Reversal of Stress.*—The reversal of stress indicated by the curves of Fig. 6 is based not only upon the varying effect of live load but also upon a changed condition of end supports, it being assumed in the one case that the ends are fully raised and, in the other case, that they are not lifted at all. The change due to live load may occur quite rapidly, but that due to a change in condition of the supports can hardly occur during the passage of a particular train. This circumstance is commonly recognized in specifications by providing that in determining the sections of members subject to reversal only such reversal need be considered as may occur during the passage of a train. During such passage, therefore, the condition of end supports is to be considered constant and may be either fully raised or not raised. The effect of this assumption is considered in detail in the example of Art. 54.

52. *Effect of "Unbroken Loads."*—In the analysis represented in Fig. 5 it has been assumed that the live load may be divided into two or more parts ("broken loads"). This assumption may or may not be legitimate, depending upon local conditions. Such a distribution of load would not occur except at very low speeds which would eliminate the question of impact.

Positive moments and positive shears are not affected by this question, as the loading assumed for these values has been unbroken. For negative moments, however, if unbroken loads are assumed, the left end cannot be assumed as held down, and the live-load moments caused in the first span by loading the second will be zero. If both spans are loaded the resulting moments are as given by the dotted curve *IV a*, Fig. 5 (*b*), and these are the maximum negative moments desired. These are then to be combined with Case I, dead load, giving the dotted curve of Fig. 6 (*a*), for the maximum total negative moments.

Negative shears will be caused by loading the first span from the left end to the section in question, the second span being unloaded.

With this loading it is assumed that the right reaction is zero and therefore that the first span acts as a simple beam. The shears for this condition are given by curve *V*, Fig. 5 (*c*). For sections near the centre, negative shear also exists when both spans are fully loaded, continuous girder action. These shears are given by curve *IV a*, Fig. 5 (*c*), and are seen to be greater than those of Case V for points on the right of *e*. Combining Case I, dead load, with Cases V and IV *a* gives the dotted line of Fig. 6 (*b*), as representing maximum negative shears with unbroken loads.

53. *Ends Latched Down.*—If the ends are not raised but are simply latched down, then in the use of unbroken loads negative reactions will occur. For negative moments the results will be the same as for broken loads, excepting for point *h*, which maximum will now be given by the dotted line *IV*, or *IV a*, Fig. 5 (*b*). For negative shears a full load on the second span will give a negative reaction at *a*, equal to $492 \times 41.4 = 20{,}400$ lbs. This will be the greatest negative shear up to the point where the shear for a fully loaded bridge (curve *IV a*) gives a greater result, or to point *d* inclusive.

Where the ends are latched down the dead-load stresses are those of Case I, but temperature variations need to be taken into account by a separate allowance. This may be done by adding the stresses resulting from a certain positive or negative end reaction, calculated on the basis of assumed temperature variation, as explained in Art. 66. These stresses will be plus or minus and should be added to all combinations of dead- and live-load stresses. Where the ends are raised, as described in Art. 43, the combination of both Case I and Case II, dead load, with the live-load stresses, makes adequate allowance for these temperature variations. The possible amount of such variations is discussed in Art. 66.

54. Centre-Bearing Truss Bridge of Two Equal Spans.—Assume a truss of the dimensions given in Fig. 7. The dead load above the turntable is assumed to be 1,200 lbs. per ft. per truss, and all applied at the lower joints. The joint load at *a*, bridge open, is taken at 18,000 lbs. The live load assumed is the engine loading of Cooper's *E*-50 class. The method of influence lines will be used in getting live-load stresses. Unbroken loads will be assumed.

55. *Case I. Dead Load, Bridge Swinging.*—The stresses for this

condition are readily found, either graphically or algebraically. Fig. 7 (*d*) gives the stress diagram and in Table *A*, p. 63, the stresses are given in Col. (2).

56. *Case II. Dead Load, Ends Raised.*—In this case the load at *a* need not be considered. The value of R_1 is given in Table 2 on p. 47, for the 4-panel truss. It is equal to (1,266 − 234) × 36 = 37,150 lbs.

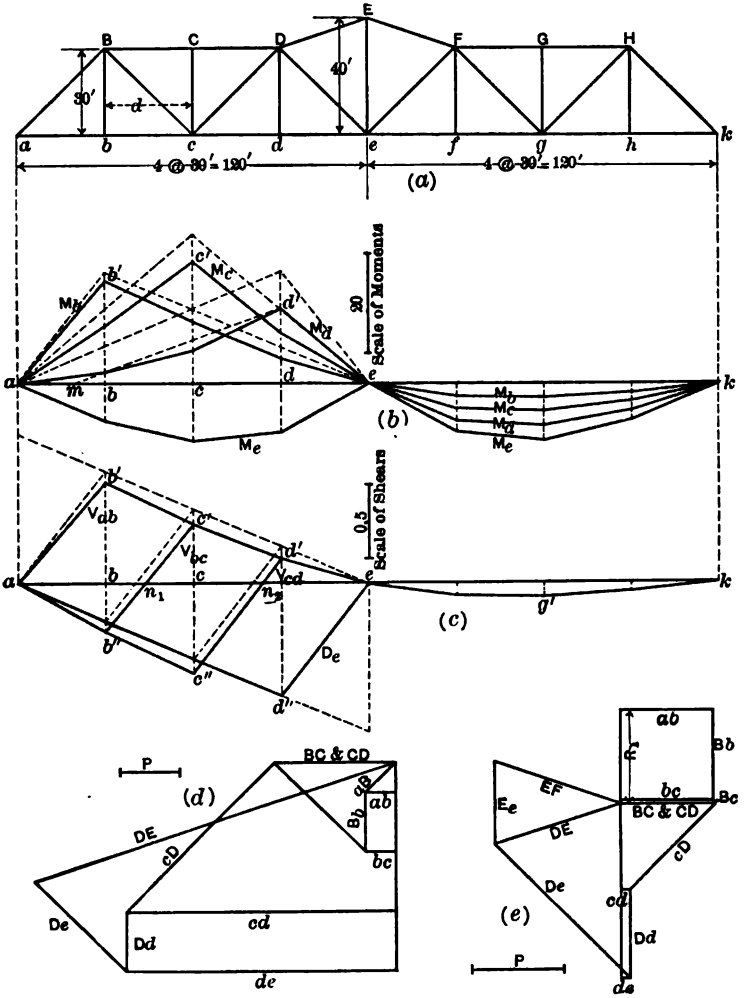

FIG. 7.

The diagram of Fig. 7 (*e*) is then readily drawn. The stresses are given in Col. (3) of the table of stresses.

57. *Case III. Live Load on First Span Only, Maximum Positive Moments and Positive Shears, Continuous-girder Action.*—This case gives maximum tension in lower chord, maximum compression in upper chord, and maximum stresses in the web members resulting from positive shears. For member *D e* the vertical component will be considered instead of the shear, as the chord *D E* takes part of the shear.

The influence lines for moments at *b*, *c*, *d*, and *e* are given in Fig. 7 (*b*). These are constructed for unit loads, using the reactions given in Table 2. Thus for joint *c* the bending moments due to load unity, placed successively at the several joints, are calculated as follows:

Position of Unit Load.	Value of R_1.	Moment at *c*.
b	.691	$.691 \times 2d - 1 \times d = 11.46$
c	.406	$.406 \times 2d = 24.36$
d	.168	$.168 \times 2d = 10.08$
f	−.082	$-.082 \times 2d = -4.92$
g	−.094	$-.094 \times 2d = -5.64$
h	−.059	$-.059 \times 2d = -3.54$

For joint *d* the work may be shortened by noting that the moments for unit load at *d*, *f*, *g*, and *h* are each equal to 3/2 times the corresponding moment at *c*, as the only change is in the lever arm of R_1. For point *b* the moments due to loads at *c*, *d*, *f*, *g*, and *h* are one-half those at joint *c*.

Having the influence lines drawn the maximum moments are found by trial for the given wheel-loads concentrations. For this purpose the influence lines may conveniently be drawn on profile or cross-section paper so that the ordinates can be read off directly. Then the wheel loads should be laid off on a strip of paper to the same scale. The locomotive may be headed in either direction but the second span is not to be loaded. On this strip should be drawn circles indicating relative weights of wheels, and the weight of each wheel written in the circle. To get any desired moment or web stress for any given position of the loads, place this strip in the given position on the base line of the influence line, read off the ordinate above each load, and

sum the products of the loads times ordinates. Two or three trials will usually serve to determine the maximum value of a moment or stress. The principle stated in Art. 123, Part I, that maximum values are caused only when a load is placed under a convex point on the curve, will aid in selecting the proper position of loads. The similarity of the influence lines to those for simple bridges will also aid in finding this position. The calculations can be shortened by dividing the loads into convenient groups, then read off the ordinate above the centre of gravity of such group, and multiply by the total weight. Only those wheels under a single straight segment of the influence line can be so grouped.

The accuracy of this method of computation is much greater than that of ordinary graphical methods. Errors are compensating rather than cumulative. If the lines are drawn to such a scale that the larger ordinates are two or three inches in length, results may easily be obtained within one per cent of the correct values.

In Fig. 7 (*c*) are shown the influence lines for shears in the panels *a b*, *b c*, and *c d*, and for the vertical component of the stress in *D e*. In this case members *D E* and *d e*, produced, intersect at *a*, so that the stress in *D e* is the same as in a simple span. Continuous-girder action is here assumed. The maximum positive shears are determined by trial, train headed toward the left and the second span not loaded. This assumes a single locomotive or two locomotives present, as the case may be. The small amount of load which might necessarily come upon the second span is neglected, as the effect in any case is small.

From the results for positive moments and positive shears, the chord and web stresses are calculated and these are given in Col. (4) of the table of stresses. The compression in *c D* is small and much less than the dead-load tension.

58. *Case IV. Maximum Live-Load Negative Moments and Negative Shears, Continuous-girder Action.*—These moments and shears are determined from the influence lines of Figs. (*b*) and (*c*) in the manner already described. For negative moments the second span only is loaded, excepting for point *e*, which requires a load extending over both spans. For negative shears three conditions of loading may need to be considered, the first span loaded on the left of the

panel in question, the second span fully loaded, and both spans loaded. For panel $b\,c$ the area $a\,b''\,n_1$ of the influence diagram, as compared to area $e\,g'\,k$ shows the relative effect produced by the first two positions mentioned. The large positive area, $n_1\,c'\,e$ shows that the third position need not be tried in this case. For panel $c\,d$, a load extending from a to n_2 will evidently cause greater shear than a load on the second span, but the positive area $n_2\,d'\,e$ being small, it is possible that the greatest shear will occur for a load on both spans. For stress in $D\,e$ both spans should be loaded. The several results are given in Cols. (5) and (6) of the table. For $B\,c$ a load on the first span gives a stress of 36,700 lbs., while a load on the second span gives a stress of 32,300 lbs. For $c\,D$ the maximum stress is caused by loading the first span only.

59. *Case V. First Span Fully or Partially Loaded, Bridge Acting as a Simple Span.*—When the ends of the truss are not fully lifted, a load on one arm is assumed to cause no reaction at the far end, in which case the loaded arm will act as a simple span. This condition will give maximum negative shears in some of the panels, as shown in the previous problem. It will also give information required in determining reversal of stress during the passage of a train. The stresses are determined exactly as for a simple span, but both kinds of web stress should be found for members $B\,c$ and $c\,D$. Influence lines for these moments and shears are shown in Fig. 7 by dotted lines. Resulting stresses are given in Col. (7) for all members, but it will be found that many of these are not needed in the combinations.

60. *Maximum and Minimum Stresses.*—In Cols. (8) and (10) are given the maximum and minimum stresses as determined by combining Case II with Case III, for stresses caused by positive moments and shears, and Case I with IV or V for stresses caused by negative moments and shears. In the latter combination it is to be carefully noted whether Case IV or Case V is to be used. Case IV is to be used only when both arms are loaded (Col. (6)), for when only one arm is loaded, with ends not raised, the far end will be lifted and the loaded arm becomes a simple span. Case V is then to be used. Member $D\,E$ is the only chord member having a tensile stress (negative moment at e) for Case IV, both spans loaded. This stress is given in Col. (6). In the case of the web members, $B\,c$, $c\,D$,

TABLE A

STRESSES IN A CENTRE-BEARING SWING BRIDGE

NOTE: + = tension, − = compression.

Member.	Dead Load.		Live Load.				Combinations.			
				Case IV − *M* and − V, Cont. G.			Dead Load Case II with Live Load Case III or IV.		Dead Load Case I with Live Load Case IV or V.	
	Case I Cantilever.	Case II. Cont. Gird.	Case III + *M* and + *V* Cont. Gird.	One Arm Loaded.	Both Arms Loaded.	Case V + M and ± *V* Simple Span.	II and III for *Max.* + *M* and + *V*.	II and IV for Reversal.	I and IV or V for *Max.* − *M* and − *V*.	I and V for Reversal.
(1)	(2)	(3)	(4)	(5)	(6)	(7)	(8)	(9)	(10)	(11)
a-b-c	− 18,000	+ 37,100	+ 125,100	− 22,800		+ 147,700	+ 162,200	+ 14,300	− 18,000	+ 129,700
c-d-e	− 162,000	+ 3,400	+ 79,800	− 68,400		+ 147,700	+ 83,200	− 65,000	− 162,000	− 14,300
B D	+ 72,000	− 38,300	− 146,500	+ 45,600		− 190,200	— 184,800	+ 7,300	+ 72,000	− 118,200
D E	+ 227,700	+ 53,300			+ 127,200		+ 53,300		+ 354,900	
a B	+ 25,500	− 52,500	− 176,700	+ 32,300		− 208,900	− 229,200	− 20,200	+ 25,500	− 183,400
B c	− 76,400	+ 1,600	+ 70,600	− 36,700(1) − 32,300(2)		+ 97,200 − 28,600	+ 72,200	− 35,100	− 105,000	+ 20,800
c D	+ 127,300	+ 49,500	− 18,700	+ 120,500(1) + 32,300(2)	+ 116,200	+ 97,180 − 28,600	+ 30,800		+ 243,500	+ 98,700
D e	− 76,400	− 76,400			− 209,500		− 76,400		− 285,900	

and $D\,e$, the greatest of the values in Cols. (6) and (7) due to negative shear are to be combined with Case I. The results in Cols. (8) and (10) give full information regarding the greatest and the least stresses in all the members.

If, in addition to the absolute maximum and minimum stresses, it is desired to know the greatest range of stress during the passage of a single train, then the maximum and minimum live-load stress must be combined with each of the dead-load cases, keeping in mind whether the structure is acting as a continuous girder or a simple span. The additional combinations for minimum values occurring during a single-train movement, the condition of the end supports remaining fixed, are given in Cols. (9) and (11). In Col. (9) are combined the stresses under Case II, with the live-load stresses from maximum *negative* moments and shears. As the structure of Case II acts always as a continuous girder, the live-load stresses to be here considered are therefore to be taken from either Col. (5) or (6), whichever is the greater. In Col. (11) the dead load is Case I, and the structure acts as a continuous girder only when loaded on both arms. The live-load stresses are therefore to be taken from Col. (6) or (7). The stresses shown in Cols. (9) and (11) will be needed in the design only when of opposite sign from those in Cols. (8) and (10) respectively. When this is the case then the member will be designed for either combination of stresses, the combination given in (8) and (9) or that given in (10) and (11). Thus member $B\,D$, for example, will be designed for a maximum compression of 184,800 lbs., with a reversal to 7,300 lbs. tension; and also for a compression of 118,200 lbs., with a reversal to 72,000 lbs. tension, using the greater of the two areas thus found. Similarly $B\,c$ will be designed for a tension of 72,200 lbs., and compression of 35,100 lbs., or a compression of 105,000 lbs., and tension of 20,800 lbs., using the greater area.

Impact allowances made to live-load stresses are made directly to the stresses given in Cols. (4), (5), (6), and (7). The resulting values are then to be combined with the dead-load stresses in the same manner as here described.

61. Use of Influence Lines for Determining Position of Loads.— If desired, the influence lines may be used to determine only the position of loads for maximum and then the value of the maximum

itself may be exactly determined from panel concentrations, calculated as explained in Part I, Art. 148. For example, the influence line for moment at *c*, Fig. 7, is very similar to that for moment at *c* in the simple span *a–e*. The *position* of loads will therefore be determined very closely if we use the position for moment at *c* in a simple span *a–e*. This is found by the usual criterion to be with wheel No. 11 at *c*. With this position of loads, the panel concentrations may then be calculated and the moment found by multiplying these loads by the ordinates to the influence line given on p. 59 and adding the results. Or, the position having been determined by applying the criterion for a simple beam, the moment may still be found by using the influence line directly, summing up the products of ordinates times wheel loads.

For moment at *d* notice that the influence line approximates to that for moment at *d* in a simple span *m e*.

The influence line for shear may be used in the same way, but in this case there is less likely to be any error in the selection of the position for maximum values.

62. Use of Equivalent Uniform Loads.—The influence lines may also be used to select a suitable equivalent uniform load, in the same manner as explained in Art. 173 of Part I. Thus for moment at *d* the dotted straight line *d′ m* may be substituted for the broken line, giving the approximate influence line *m–d′–e*. The proper equivalent load is then the uniform load for moment at *d* in a beam *m e* which is at the 0.3 point in a 100-ft. beam. This is found by Fig. 4 to be 3,340 lbs. per foot. This load, then, multiplied by the area of the true influence line, *a–d′–e*, will give the desired moment. The ordinates to this influence line are 2.19, 6.54, and 15.12, respectively, and the area = 715.5. The moment at *d* = 715.5 × 3,340 = 2,390,000 ft. lbs., and the stress in *c–d–e* = 79,700 lbs. The value obtained from the concentrated loads was 79,800 lbs.

Again, the influence line for positive shear in panel *b c* is $n_1 c' e$. This is of nearly the same form as that for moment at *c* in a beam $n_1 e$, or at the 0.2 point in a beam 77 ft. long. From Fig. 4 this is found to be 3,500 lbs. per ft. The area of the influence diagram is 14.58 and the stress in *B c* is therefore 14.58 × 3,500 × 1.414 = 72,200 lbs. The value given in Table A is 70,600 lbs.

A convenient way to carry out this method is to calculate all stresses for a uniform load of unity per foot and then to multiply the stresses so found by the proper equivalent load determined for each member.

63. True Reactions Calculated from Deflections.—It was noted in Art. 34 that in the application of the usual beam formulas to trusses there are two sources of error: (1) that due to the assumption of a constant moment of inertia and (2) that due to the neglect of the web distortions. The first can be avoided by the use of formulas for variable moment of inertia, but the latter only by the application of the theory of deflections or of redundant members as explained in Chap. VII, Part I. Generally it is found that the two sources of error mentioned tend to compensate, so that if correction is made for variable moment of inertia and not for web distortion, the result is apt to be more in error than when both are neglected. If, therefore, it is desired to employ a more exact method than the usual one, the method of redundant members should be used. While the usual methods give results accurate enough for most purposes it is desirable to know in general what the range of error may be, and in some cases to make a detailed analysis by the exact method.

As the theory of redundant members requires a knowledge of the cross-sections of all the members, it is necessary, before this method can be applied, to determine these sections from calculations based on the usual beam theory, or some other approximate method. The sections being known the exact stresses may then be found. If the preliminary sections are too greatly in error they can be corrected accordingly. Such a change in section will cause some change in the reactions and the stresses, but not generally enough to require a second calculation.

In the application of the method of redundant members it will be convenient to consider the centre reaction R_2 as redundant. Then, as in Art. 32, the value of R_2 is given by the equation

$$R_2 = -\frac{\Sigma \frac{S' u l}{E A}}{\Sigma \frac{u^2 l}{E A}} \quad . \quad . \quad . \quad . \quad . \quad . \quad (1)$$

in which

S' = stress in any member due to the given loads, with the structure supported at the two ends;

u = stress in any member due to one pound upward load applied at the centre;

l and A = length and cross-section, respectively, of any member.

By the application of eq. (1) for a unit load at each of the loaded joints, the influence line for R_2 can be drawn, which can be utilized very readily in the construction of the true influence lines for moments and shears. The labor of the calculations will be reduced if two loads of unity be assumed, symmetrically spaced. Thus in Fig. 7, to determine R_2 for a load at c, assume a load unity at both c and g and determine the value of R_2 for these two loads. For a symmetrical load such as assumed the stresses S' need be calculated for one-half only. Also the stresses u need be calculated for one-half only. Then substituting in (1) the result will be one-half the reaction for the two loads. But the reaction for the two loads is equal to twice that for one of them, hence the result obtained by using summations for one span only is the correct value for R_2 for a single load.

The graphical method is very convenient in such problems as these. A single displacement diagram for the bridge supported at the

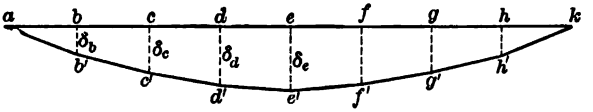

FIG. 8.

ends, and loaded with unit load at the centre is all that is required. From this diagram the deflection curve of the lower chord joints is drawn. Let Fig. 8 represent such deflection curve. Then by the principles explained in Arts. 220 and 223, Part I, the deflection at e caused by a unit load at any other point d is equal to δ_d. But a unit load (or reaction) at e causes a movement of δ_e, hence the reaction at e due to a unit load at d is equal to δ_d/δ_e, or, *in general*

$$R_2 = \frac{\delta}{\delta_e} \quad . \quad . \quad . \quad . \quad . \quad . \quad . \quad . \quad (2)$$

in which δ is the deflection of any given joint due to one pound at e, bridge considered supported at the ends only, δ_e is the deflection at joint e, and R_2 is the center reaction due to one pound placed at the given joint. The influence line for R_2 is therefore obtained by plotting the deflection curve to such a scale that δ_e is unity, or by replotting the values δ/δ_e.

64. Application to the Truss of Fig. 7.—The method of redundant members will be applied to the truss of Fig. 7 and the true influence lines constructed. The graphical method will be used. The lengths, cross-sections, stresses, and values of ul/A for unit load at e are given in the table below. As the direction of R_2 is not in question the unit load at e will be taken as acting downward.

Member.	Length l.	Cross-section A.	u.	$\frac{ul}{A}$.
a-b-c	720	17.3	+ .50	+ 20.8
c-d-e	720	19.8	+ 1.50	+ 54.6
B-C-D	720	28.0	− 1.00	− 25.7
a B	506.0	36.1	− .707	− 9.9
B c	506.0	19.8	+ .707	+ 18.1
c D	506.0	21.4	− .707	− 16.7
D e	506.0	44.8	0	
D E	379.4	27.9	− 1.58	− 21.5
E e	480	33.4	+ 1.00	+ 14.4

The quantities in the last column, divided by E, are the deformations to be used in constructing the displacement diagram. The quantity E may be omitted as only relative results are needed. The diagram may be started at the centre vertical, the point e being assumed stationary. The diagram is shown in Fig. 9. One-half only is drawn. From this diagram the vertical movement of all joints with respect to a horizontal line a–k may be measured. Dividing each deflection by the deflection of joint e and plotting the results; gives the influence line for R_2 shown in Fig. 10 by the full line $a\,e'\,k$. For convenience the ordinates are plotted above the axis. The numerical values of the ordinates, or values of R_2, are as follows:

Point Loaded.	R_2
b	0.354
c	0.685
d	0.940
e	1.000

By the approximate method previously used the corresponding values of R_2 are: 0.368; 0.688; and 0.914, respectively.

Having the influence line for R_2, the other reactions, and the moment and shear at any section for a load at any point can be determined and any desired influence line drawn. Or, we may proceed more quickly as follows: Consider the moment at b, Fig. 10. A load P placed on the structure at any point, as c, will cause a moment at b which may be calculated in two parts, (1) the moment which would result if the structure were supported at the ends only, and (2) the moment due to the centre reaction R_2. The moment due to (1) is equal to $\frac{P(2l - kl)}{2l} \times a = \frac{P(2-k)}{2} \cdot a$; and that due to R_2 is equal to $\frac{R_2}{2} \times a$. If y_c = ordinate $c\,c'$, then $R_2 = P\,y_c$, and the total moment $= P\,[(2-k) - y_c]\,\frac{a}{2}$. But ordinate $c\,c'' = 2 \times \frac{2l - kl}{2l} = 2 - k$, hence $c'\,c''$ $= (2-k) - y_c$. Therefore if $c'\,c''$ be multiplied by $a/2$ the result will be the moment at b for a unit load at c. Likewise for a load at any other joint, the ordinate at the joint between the straight lines $a\,b'' - b''\,k$, and the curve $a\,e'\,k$, if multiplied by the constant $a/2$, will represent the moment at b. The shaded area therefore serves as the influence area for moment at b.

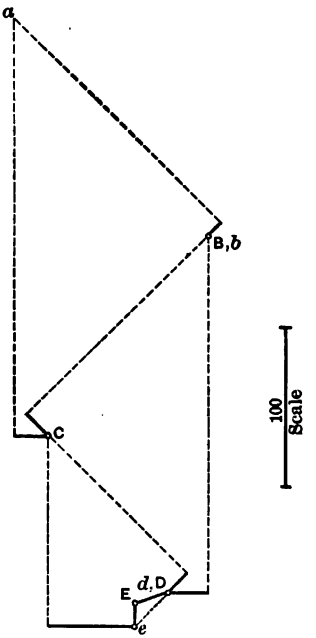

FIG. 9.

The influence diagram may be reconstructed to a horizontal base and true scale by plotting the ordinates $b'\,b''$, $c'\,c''$, etc., multiplied by $a/2$. The replotted diagram will be similar to the diagrams of Fig. 7 (b).

For the other points, c and d, the influence lines are obtained by drawing the straight lines $a\,c''$ and $a\,d''$. The true ordinates are then equal to the ordinates between these lines and the curve for R_2, multiplied in each case by $a/2$, where a is the distance of the moment centre from the left end of the span.

The true influence lines being thus drawn the exact stresses can be determined in the same manner as the approximate values; but a comparison of the two methods can readily be made by comparing the curves for the approximate and exact values of R_2. In Fig. 10 the dotted curve $a\,e'\,k$ gives the values by the approximate method, corresponding to the analysis already made. The error in stresses is clearly indicated by the area enclosed between these two curves as compared to the area of the influence diagram for any particular moment (or shear). In this case the errors are seen to be very small. For example, the influence areas for positive moments (multiplied by $a/2$), are as follows:

	Exact.	Approximate.	Per Cent Error.
M_b	113.5	113.8	+ 0.3
M_c	137.0	137.7	+ 0.5
M_d	70.5	71.6	+ 1.5

For shears a similar method of constructing influence lines may be used. Consider the shear in panel $b\,c$, Fig. 10. For unit load at c, truss supported at

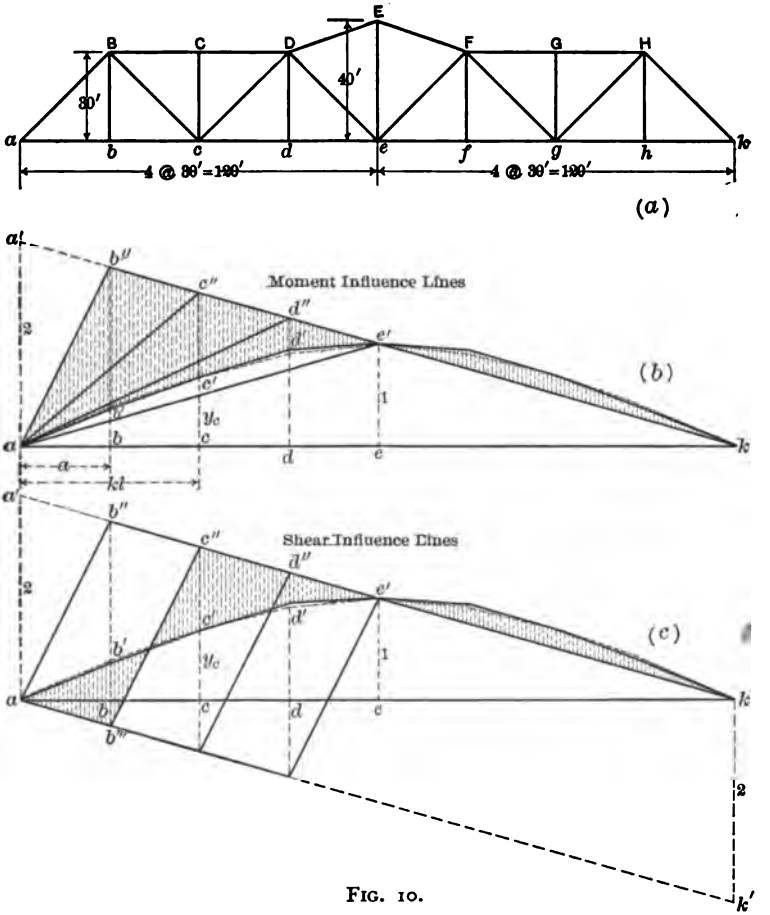

FIG. 10.

ends only, the shear in panel $b\,c$ is equal to $P\frac{2l - kl}{2l} = P\frac{2 - k}{2}$; and the shear due to $R_2 = R_2/2 = \frac{y_c}{2}$. The total shear $= P[(2 - k) - y_c] \times \frac{1}{2}$. The ordinate $c'\,c'' = (2 - k) - y_c$, hence the shear $= c'\,c'' \times \frac{1}{2}$. The

ordinates of the shaded area in general, multiplied by $\frac{1}{2}$, will therefore give the true influence line for shear in panel $b\,c$. The line $a\,b''\,'\,k'$ is parallel to $c''\,k$; and the line $a\,b''\,'\,c''\,k$ has double the ordinates of the influence line for shear in a simple truss. The shear influence lines for the other panels are drawn as indicated.

The method of constructing influence lines here described may of course be used in the usual approximate analysis. The curve for R_2 is first constructed, after which all the influence diagrams are drawn without further calculation. They may then be redrawn, if desired, on a straight base line and to a correct scale. The method here used will be found of general utility also in the analysis of arches and suspension bridges.

65. Deflection under Dead Load and Amount of Uplift Required.—In order to design the end-lifting mechanism it is necessary to know the amount of uplift required and the force necessary to produce it. The full dead-load deflection, bridge swinging, is given by the general formula $\Delta = \Sigma \frac{S\,u\,l}{E\,A}$, where S = dead-load stress, bridge swinging, and u = stress for 1 pound applied at the end. The amount of upward deflection produced by a 1-pound force is $\delta = \Sigma \frac{u^2\,l}{E\,A}$. The total force required to remove all the dead-load deflection (the true dead-load reaction for a continuous girder) is therefore $\Sigma \frac{S\,u\,l}{E\,A} \Big/ \Sigma \frac{u^2\,l}{E\,A}$, exactly as found in Art. 63 for the centre reaction R_2. If the ends are to be lifted only sufficiently to prevent the live load from raising the end from its support, then the movement required must be sufficient to develop a reaction equal to the maximum negative live-load reaction. If this be R' then the required movement $= \delta\,R'$. If any other desired amount of reaction is to be obtained, the distance to be moved is readily determined in the same manner.

In the truss of Art. 64 the value of $\Sigma \frac{S\,u\,l}{E\,A}$ for the dead load, Case I, is found to be 1.47 in., which is the full deflection from normal position, and is the uplift required if the ends are to be fully lifted. The value of $\Sigma \frac{u^2\,l}{E\,A} = 0.0000268$ in. The resulting reaction (true dead-load reaction) $= 1.47 \div 0.0000268 = 54{,}700$ lbs. The maximum negative live-load reaction = 22,800 lbs. (stress in

a b c in Col. (5), Table A). To prevent hammering, therefore, the uplift must be at least 22,800 × 0.0000268 = 0.612 in. In practice, the uplift would be made somewhat greater than this in order to provide for variations in temperature (Art. 66), and imperfect adjustment.

66. Effect of Temperature Variations.—A very important question, and one of especial significance when discussing the accuracy of working formulas, is that of the effect of a variation of temperature between different members of a swing bridge. The effect on reactions of any given difference of temperature can very quickly be found in the same manner as the true reactions for loads.

Let t = change of temperature of any member; ω = coefficient of expansion, = .0000065 per 1° F.; l = length of member. Then $\omega t l$ = total change of length of any member. The deflection of the end of the truss due to the change of length of this member will be $u \omega t l$, where u has the same significance as in the previous calculations. For a change of temperature in any number of members the end deflection will be

$$\Delta_t = \Sigma u \omega t l. \quad . \quad . \quad . \quad . \quad . \quad . \quad (3)$$

The reaction necessary to produce a like deflection, or the reaction caused by the assumed temperature changes, will be

$$R_t = \Delta_t / \delta = \Sigma u \omega t l / \Sigma \frac{u^2 l}{E A}. \quad . \quad . \quad . \quad . \quad (4)$$

For example, suppose the lower chord of the bridge of Fig. 7 drop in temperature 10° below that of the remaining members. In this case $\omega t l$ for each chord member = 0.0234 in. and $\Sigma u = 8$ (one pound at *a*), whence the deflection = 0.187 in. and R_t = 0.187/0.0000268 = 6,960 lbs.

Observation of the variation in deflection of swing bridges indicates that the differences in temperature may readily amount to 30°, thus giving rise to variations in reaction of as much as 50 per cent of the normal dead-load reaction.

The great effect of temperature variations evidently renders useless any great refinement in calculations and indicates that the ordinary formulas are accurate enough for all ordinary cases.

67. Counter-balanced Swing Bridges.—Frequently in the case of narrow channels it is necessary to avoid the construction of a pier in the

channel. In such a case the pivot pier must be built at the margin and a single arm of the swing span made of the length required for the opening. The other span is needed only for balancing the channel span and is made as short as convenient, and weighted with pig-iron or other heavy material. It may or may not support a panel of the live load. The stresses are found by the application of the general formula for unequal spans (Art. 23), and involves no new principles.

SECTION III.—THE RIM-BEARING SWING BRIDGE

68. Rim-Bearing Swing Bridge,—Truss Continuous over Four Supports.—A method of construction formerly quite general is shown in Fig. 11. The central panel is fully braced and the truss is continuous over four supports.

With some writers it has been customary to apply to this form of truss the formulas for a continuous beam of four supports,—formulas based on the assumption of uniform moment of inertia and a neglect of deflection due to shearing stresses. These formulas give results closely approximate for beams and long-span trusses, and fairly good results for two-span swing bridges; but their application to trusses of such short spans as here considered leads to very erroneous conclusions. With only one span loaded large negative reactions are obtained at B or C, reactions much greater than can ever really occur, and which greatly exceed the dead-load positive reactions. To furnish these negative reactions some form of anchorage would have to be provided at B and C, a thing quite impracticable in a swing bridge.

Again, the central span BC is so short that the effect of the web distortions (neglected in the beam theory) becomes of great importance and an exact analysis will show that the resultant dead- and live-load reaction at B or C will never be negative (the negative live-load reaction will never be large and always much less than the dead-load positive reaction). An example will be given showing the results obtained by the two methods of calculation.

69. *Calculation by Continuous-girder Formulas.*—Considered as a beam continuous over four supports, and with equal end spans, the

reactions due to a single load on the first span are given by the following formulas derived in Art. 25:

$$\left.\begin{aligned} R_1 &= P\,(1-k) - \frac{2+2n}{N} P\,(k-k^3) \\ R_2 &= P\,k + \frac{2+5n+2n^2}{nN} P\,(k-k^3) \\ R_3 &= -\frac{2+3n+n^2}{nN} P\,(k-k^3) \\ R_4 &= \frac{n}{N} P\,(k-k^3) \end{aligned}\right\} \quad . \quad . \quad . \quad (1)$$

in which n = ratio of centre to end span and $N = 4 + 8n + 3n^2$.

Assume, for example, a truss of the same span lengths as the

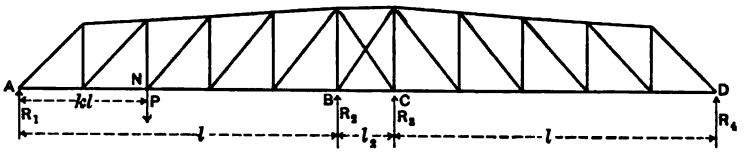

FIG. 11.

structure of Art. 76, and suppose this to be rigidly braced in the centre panel and to be treated as a beam continuous over four supports (Fig. 13). Assume a dead joint load of 30,000 lbs., and a live joint

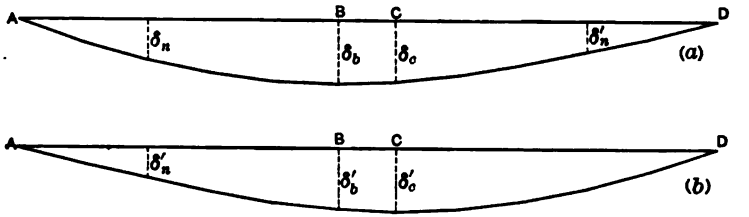

FIG. 12.

load of 75,000 lbs. The value of $n = 0.107$ and $N = 4.89$. Applying eq. (1) we find, for dead load, $R_1 = R_4 = +\ 56{,}100$ lbs., and $R_2 = R_3 = +\ 93{,}900$ lbs. The value of R_3 for full live load on the first span

is by eq. (1), $R_3 = -\frac{2+3n+n^2}{nN} P \Sigma (k-k^3)$, in which $\Sigma (k-k^3)$ is the summation for the several load points on the first span. From this we find $R_3 = -486{,}000$ lbs. The total reaction at h is therefore $-486{,}000 + 93{,}900 = -392{,}100$ lbs. To provide this amount of negative reaction would require a strong and rigid anchorage, an arrangement of much difficulty. It is further to be noted that if R_3 is negative, R_4 is at the same time positive. One assumption sometimes made is that whenever the net reaction at h becomes negative this point rises slightly from the support and the bridge becomes a two-span structure with supports at a, g, and n. Such action would probably occur, but would also be objectionable as it would cause a very unequal distribution of load on the drum and turntable. It will be shown, however, that the true reaction at h is never likely to be negative.

70. *Calculation by Method of Redundant Members.*—Applying the theory of redundant members to the truss of Fig. 11, it is noted that the structure is doubly indeterminate. The two redundant forces may conveniently be taken as the reactions R_2 and R_3. With these removed the truss is a simple span, the stresses in which are readily calculated for any given loading. As developed in Art. 225, Part I, let

S' = stress in any member due to the given loads, truss supported at A and D only;

u = stress under the same conditions for 1-pound reaction at B;

v = stress under the same conditions for 1-pound reaction at C.

S = total actual stress in any member due to given loads and all reactions.

Then
$$S = S' + u R_2 + v R_3. \quad . \quad . \quad . \quad . \quad . \quad (2)$$

Also, since the deflection at B is zero,
$$\Sigma \frac{S u l}{E A} = 0, \quad . \quad . \quad . \quad . \quad . \quad . \quad . \quad . \quad (3)$$

and likewise, as the deflection at C is zero,
$$\Sigma \frac{S v l}{E A} = 0. \quad . \quad . \quad . \quad . \quad . \quad . \quad . \quad . \quad (4)$$

Substituting the value of S from (2) we have
$$\Sigma \frac{S' u l}{E A} + R_2 \Sigma \frac{u^2 l}{E A} + R_3 \Sigma \frac{u v l}{E A} = 0, \quad . \quad . \quad . \quad (5)$$

and $$\Sigma \frac{S' v l}{E A} + R_2 \Sigma \frac{u v l}{E A} + R_3 \Sigma \frac{v^2 l}{E A} = 0. \quad . \quad . \quad . \quad (6)$$

The graphical method explained in Art. 223, Part I, can be utilized to calculate the variations summations of eqs. (5) and (6), and it will be found convenient to determine the reactions for a load of 1 pound at any joint.

In accordance with the method above referred to, it will first be necessary to construct a displacement diagram of the truss for a one-pound load applied at B, truss supported at A and D. Then from this diagram the deflections of each of the lower joints is determined with respect to the supports A and D, and a deflection curve constructed. Suppose Fig. 12 (a) represent such deflection curve. Then suppose a similar curve to be drawn for a one-pound load at C. For a symmetrical truss, like the one considered, this will be similar to the curve for load at B and need not be actually constructed, but for clearness it is shown in Fig. (b).

Now consider a unit load applied at any joint N. In accordance with the principles explained in Art. 220, Part I, the ordinate δ_n will be the deflection of joint B due to this unit load; and the ordinate δ'_n, Fig. (b), will be the deflection of joint C for this load. Furthermore, the ordinate δ_c is the deflection of B for one pound at C, and the ordinate δ'_b is the deflection of C for one pound at B. Noting the significance of the various summations in eqs. (5) and (6), and assuming S' to be the stress in any member for a one-pound load at N, we have the following identities:

$$\left.\begin{aligned} \Sigma \frac{S' u l}{A} &= -\delta_n; \ \Sigma \frac{S' v l}{A} = -\delta'_n \\ \Sigma \frac{u^2 l}{A} &= \delta_b; \ \Sigma \frac{v^2 l}{A} = \delta'_c \\ \Sigma \frac{u v l}{A} &= \delta_c = \delta'_b. \end{aligned}\right\} \quad . \quad . \quad . \quad . \quad (7)$$

Substituting in (5) and (6), and neglecting the quantity E, we have

$$\left.\begin{aligned} -\delta_n + R_2 \delta_b + R_3 \delta_c &= 0 \\ -\delta'_n + R \ \delta'_b + R_3 \delta'_c &= 0 \end{aligned}\right\} \quad . \quad . \quad . \quad . \quad (8)$$

Solving these for R_2 and R_3 we derive

$$\left.\begin{aligned} R_2 &= \frac{\delta_n \delta'_c - \delta'_n \delta_c}{\delta_b \delta'_c - \delta'_b \delta_c} \\ R_3 &= \frac{\delta_n \delta'_b - \delta'_n \delta_b}{\delta_c \delta'_b - \delta'_c \delta_b}. \end{aligned}\right\} \quad . \quad . \quad . \quad . \quad . \quad . \quad (9)$$

For a symmetrical truss, as here assumed, $\delta_b = \delta'_c$, and we also have, in all cases, $\delta_c = \delta'_b$, hence (9) reduces to

$$R_2 = \frac{\delta_n \delta_b - \delta_n' \delta_c}{\delta_b^2 - \delta_c^2}. \quad . \quad . \quad . \quad . \quad . \quad (10)$$

$$R_3 = \frac{\delta'_n \delta_b - \delta_n \delta_c}{\delta_b^2 - \delta_c^2}. \quad . \quad . \quad . \quad . \quad . \quad (11)$$

The value of δ'_n is obtained from Fig. 12 (*a*) on the right of the centre.

From eqs. (10) and (11) the reactions R_2 and R_3 can be very quickly calculated for a unit load at any joint, and from them the true reactions for any loading. It will be noted that R_3 will be + or − according as the value of $\delta'_n \delta_b$ is greater or less than $\delta_n \delta_c$.

Applying this method to Fig. 13, the displacement diagram is first to be drawn for one pound at *g*, truss supported at *a* and *n* only. The

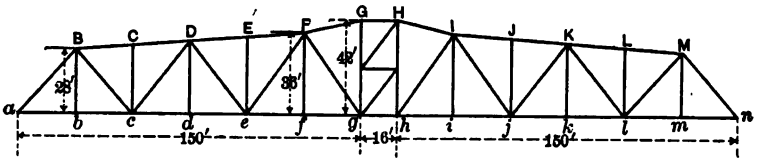

FIG. 13.

cross-sections and lengths of the various members, excepting the centre diagonals, are given in Art. 76. To avoid the multiple system the centre diagonals will be assumed as shown in Fig. 13 and to be of 24 sq. in. each in section. The stresses *u* are then calculated, the values of $u\,l/A$, and finally the displacement diagram drawn. The values of the several deflections (times *E*) measured from this diagram are as follows, δ denoting the deflection of any joint on the left and δ' that of the corresponding joint on the right:—

Joint.	δ	δ'
b	126	119
c	235	225
d	338	322
e	416	398
f	465	447
g	480	
h	466	

Substituting in eqs. (10) and (11) we derive the following values for R_2 and R_3 for unit loads:

Joint Loaded.	R_2	R_3
b	0.378	−0.118
c	0.609	−0.122
d	0.934	−0.236
e	1.089	−0.229
f	1.137	−0.173
First span fully loaded	4.147	−0.879

From this we find that for the first span fully loaded with P = 75,000 lbs., R_2 = 311,000 lbs., and R_3 = − 66,500 lbs. The total dead- and live-load reaction at h = + 98,000 − 66,500 = + 31,500 lbs. We also find, from moments about D or A, the true values of R_1 and R_4 for first span loaded, to be + 155,000 lbs. and − 24,500 lbs., respectively.

71. *Comparison of Results.*—The value of R_3 was found in Art. 69, by the continuous-girder theory, to be −486,000 lbs. Comparing this with the correct value of − 66,500 lbs. given above it will be seen that the continuous-girder method is quite inapplicable to such a case. Again, the value of R_4 is found by the two methods to be −24,500 and + 2,400 lbs., respectively.

It may be noted here that the method of analysis of Art. 76, for the truss partially continuous over four supports, may be applied with little error for end reactions to the case here considered. By that method the value of R_1 for first span fully loaded is 163,900 lbs., and R_4 = − 23,600 lbs. R_2 = 211,100 lbs.

In trusses of this type the formulas for a two-span bridge are often

used for calculating the end reactions, with fairly satisfactory results. Thus for the 1st span loaded the coefficients on page 47 give a value of $R_1 = 160{,}000$ lbs., and $R_3 = -27{,}300$ lbs., compared to values of 155,000 and $-24{,}500$ lbs. respectively.

72. *Stresses in Centre Diagonals.*—If the reaction at *h* had the large negative value found by the application of the beam formulas the shear in span *g h* would be 484,000 lbs., giving a stress in each of the diagonals of 304,000 lbs., which would require the use of a large member as assumed. Considering the true reactions, however, the shear is equal to $R_3 + R_4 = -91{,}000$ lbs., giving a maximum stress of only 57,200 lbs. in each diagonal or only 2,400 lbs. per sq. in. for the section assumed. If smaller members had been used their *unit* stress would have been only slightly larger as the deformation is necessarily about the same. This is an important deduction, for it shows that whatever the size of member used in this panel the *unit* stress will be low.

From these considerations it is evidently advisable to employ for the diagonals of this panel, members of only sufficient sectional area to stiffen the structure, when open, against wind and any unbalanced dead load. Then in the analysis these small members may be neglected and the calculations made as explained in the following article. Large members serve no useful purpose. In recalculating old structures, where large members have been used, the foregoing analysis shows that they may likewise be neglected. In modern practice small diagonals are generally employed, making a truss partially continuous over four supports (Art. 74).

73. **Truss Continuous over Three Supports.**—To avoid the objection to the truss continuous over four supports, noted in Art. 68, some

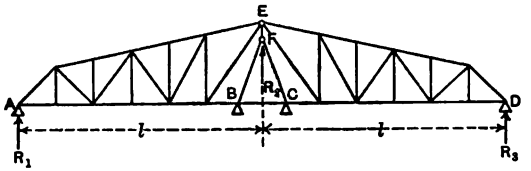

FIG. 14.

trusses have been constructed of the form shown in Fig. 14. In this form the link *E F* carries the load at the centre to the rigid frame *B F C*. The length of the panel *B C* is made equal to the width of the

truss in order than the weight upon the turntable may be uniformly distributed. The length of the other panels in the lower chord is independent of BC. The analysis is precisely the same as for a simple two-span continuous girder, with centre support at F.

74. Truss Partially Continuous over Four Supports; Equal Moments at the Centre Support.—Fig. 15 shows a form of construction which also avoids the objection noted in Art. 68. In this form the

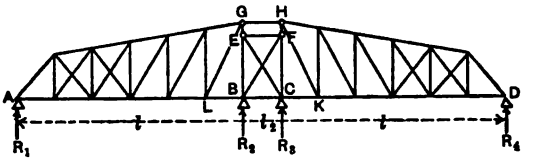

FIG. 15.

rigid frame $EFBC$ supports the truss by means of the short links EG and FH. The portion BC of the frame is a part of the lower chord of the bridge; in other respects the frame may be considered a part of the pier. There being no diagonals in the panel $EFHG$, there can be no shear transmitted across this panel, and the moments at E and F must always be equal.

The same object may be secured in a simpler way by using full diagonal bracing (Fig. 17) of small section, as mentioned in Art. 72. These members are then neglected in the calculations, giving a condition of equal moments at the centre supports exactly as in Fig. 15.

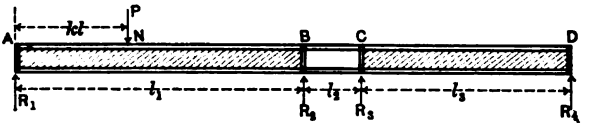

FIG. 16.

Formulas for reactions for such a case may be derived as for beams and will be found to apply with about the same accuracy as in the case of the two-span truss.

75. *Reactions for a Beam Partially Continuous over Four Supports; Equal Moments over Centre Supports.*—Fig. 16 represents a continuous beam on four supports. It is assumed, however, that throughout the middle span the beam has the same moment of inertia as elsewhere but

is not capable of resisting shear, so that the bending moment is constant from B to C. The value of R_1 will be derived for a load P on the first span.

It will be convenient to solve this problem by the use of the general formula for deflection as applied to beams, derived in Chapter VII, Part I. It is

$$D = \int \frac{M\,dx}{EI} \cdot m, \quad \ldots \ldots \ldots \ldots \quad (12)$$

in which

D = deflection of any point;

M = moment at any section due to the given loads;

m = bending moment at any section due to a force of 1 pound applied at the point whose deflection is desired.

The reaction R_1 will be considered as a redundant reaction and its value determined by equating to zero the deflection of the beam at this point. Let M' = moment at any section due to the given loads, with the reaction at A removed, and m = moment due to a reaction of one pound at A. Then, as in Art. 63,

$$M = M' + R_1 m. \quad \ldots \ldots \ldots \quad (13)$$

Substituting in (12), placing $D = 0$ and solving, we have (assuming E and I constant)

$$R_1 = -\frac{\int_A^D M' m\,dx}{\int_A^D m^2\,dx}. \quad \ldots \ldots \quad (14)$$

The values of the integrals for the case of a single load P in the first span will now be determined. With the support at A removed the other reactions are determinable by statics from the condition of zero shear in the span BC. If R'_2, R'_3, R'_4, and M'_2 and M'_3 represent the reactions and moments due to the load P, with R_1 removed, we have

$$R'_2 = P. \quad \ldots \ldots \ldots \quad (15)$$

Also $M'_3 = M'_2 = -P\,l_1\,(1 - k)$, and hence

$$R'_4 = \frac{M'_3}{l_3} = -P\,(1 - k)\,\frac{l_1}{l_3}, \quad \ldots \ldots \quad (16)$$

and

$$R'_3 = -R'_4 = P\,(1 - k)\,\frac{l_1}{l_3}. \quad \ldots \ldots \quad (17)$$

The values of the quantities M' and m, and the several integrals, for the various parts of the beam $A\,E$, $E\,B$, $B\,C$, and $C\,D$ are given in the following table. The origin for $A\,B$ is conveniently taken

Section.	M'	m	$M'm$	m^2	$\int M'm\,dx$	$\int m^2\,dx$
$A\,N$	0	x	0	x^2	0	$\left.\begin{matrix}\\ \\ \end{matrix}\right\}\frac{l_1^3}{3}$
$N\,B$	$-P(x-k\,l_1)$	x	$-P(x^2-k\,l_1\,x)$	x^2	$-\frac{P l_1^3}{6}(2-3k+k^3)$	
$B\,C$	$-P\,l_1(1-k)$	l_1	$-P\,l_1^2(1-k)$	l_1^2	$-P\,l_1^2(1-k)\,l_2$	$l_1^2\,l_2$
$C\,D$	$-P\frac{l_1}{l_3}(1-k)\,x$	$x\frac{l_1}{l_3}$	$-P\frac{l_1^2}{l_3^2}(1-k)\,x^2$	$x^2\frac{l_1^2}{l_3^2}$	$-\frac{P\,l_1^2}{3}(1-k)\,l_3$	$\frac{l_1^2\,l_3}{3}$

at A and for $C\,D$ at D. Substituting the summations in (14) we derive the formula

$$R_1 = P\left[(1-k) - \frac{l_1(k-k^3)}{2\,l_1 + 6\,l_2 + 2\,l_3}\right]. \quad . \quad . \quad . \quad (18)$$

If $l_1 = l_3 = l$, then

$$R_1 = P\left[(1-k) - \frac{l(k-k^3)}{4\,l + 6\,l_2}\right]. \quad . \quad . \quad . \quad . \quad (19)$$

Compared to eq. (4), Art. 42, it is observed that (19) differs from (4) only in the addition of the term $6\,l_2$ in the denominator.

Having determined R_1, the following formulas are readily derived.

$$R_2 = P - R_1 = P\left(k + \frac{l_1(k-k^3)}{2\,l_1 + 6\,l_2 + 2\,l_3}\right). \quad . \quad . \quad (20)$$

$$R_3 = -R_4 = P\,\frac{l_1(k-k^3)}{2\,l_1 + 6\,l_2 + 2\,l_3}\cdot\frac{l_1}{l_3}. \quad . \quad . \quad . \quad . \quad (21)$$

76. Example of Truss Bridge, Partially Continuous over Four Supports.—A complete analysis will be made of the truss of Fig. 17. The diagonals in the centre panel are of small cross-section and will be omitted in the calculations, thus making the truss partially continuous over four supports. The formulas of Art. 75 will be used, after which the true reactions will also be determined by the method of redundant members.

Assume a dead load of 1,325 lbs. per foot or 33,100 lbs. per joint. A load of $\frac{1}{4}\,W$ will be assumed for joint a. For live load use Cooper's E-50 loading with 50% increase for impact on all members excepting vertical hangers, which

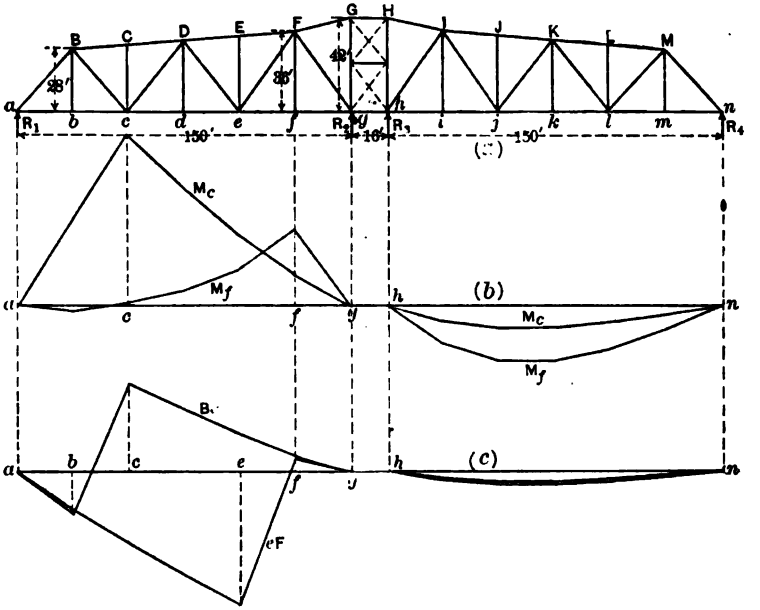
B C D E F G H I J K L M
28'
35'
42'
a b c d e f g h i j k l m n
R1 R2 R3 R4
150' 150'
(a)
Mc
Mf
(b)
Mc
Mf
B.
(c)
eF

FIG. 17.

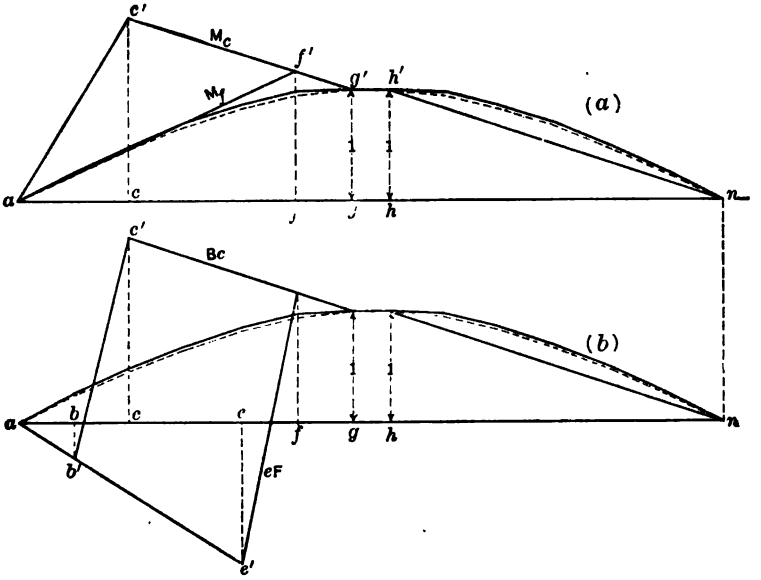
c' Mc f' g' h'
Mf
(a)
a c f g h n
c' Bc
(b)
a b c e f g h n
b'
eF
e'

FIG. 18.

need not be considered in this analysis. This is equivalent to the use of loading of *E*-75 without impact.

Reaction Coefficients. Applying eqs. (19) and (21) we have the following values of left reactions for unit loads:

Joint Loaded.	R_1	Joint Loaded.	R_1
b	.798	*i*	− .0549
c	.603	*j*	− .0797
d	.419	*k*	− .0808
e	.254	*l*	− .0638
f	.112	*m*	− .0349
	Σ = 2.186		Σ = − .3141

Dead-Load Stresses.—For Case I, the structure is a double cantilever. The stresses are given in Col. (2) of Table *B*. For Case II, the truss is a continuous girder and $R_1 = (2.186 - .314) \times W = 61{,}960$ lbs. The stresses are given in Col. (2) of the table on p. 85.

Live-Load Stresses.—These are found from influence lines drawn for moments and vertical components of web stress. Fig. 17 shows the influence lines for moments at *c* and *f* and for vertical components of stress in *B c* and *c F*. Having these lines drawn the stresses are found by trial, using unbroken loads. The results are given in Cols. (4), (5), and (6) of the table. Col. (7) gives the stresses when considered as a simple span, also determined from influence lines.

Combination of Stresses.—The combinations of stresses are made as in Art. 60. Cols. (8) and (9) taken together, and Cols. (10) and (11), give the greatest range of stress which can occur during the passage of a single train. It should be remembered that Col. (5) can be combined with Col. (3) only, as the structure becomes a simple span when ends are not raised and one arm only is loaded. In Col. (10) several of the values are a maximum for Case I alone.

Sectional Areas.—From the maximum and minimum stresses here found the cross-sections of the several members have been determined, using the following working stresses:

for tension, 16,000 lbs. per sq. in. on net section;

for compression, $16{,}000 - 70\frac{l}{r}$.

For alternating stresses add 50 per cent of the lesser to each stress and take the greater of the two areas so determined. The results are as follows:

Member.	Gross Area sq. in.	Member.	Gross Area sq. in.
a b c	27.0	*a B*	18.8
c d e	36.6	*B c*	19.8
e f g	27.5	*c D*	19.8
g h	41.3		
B C D	33.0	*D e*	30.3
D E F	25.0	*e F*	39.9
F G	39.8	*F g*	45.1
G H	36.0	*G g*	19.8

TABLE B

STRESSES IN A RIM-BEARING SWING BRIDGE

Note: + = tension − = compression.

Member.	Dead Load.		Live Load.				Combinations.			
				Case IV − *M* and − *V* Cont. Girder.			Dead Load Case II with Live Load Case III or IV.		Dead Load Case I with Live Load Case IV or V.	
	Case I Cantilever	Case II Cont. Gird.	Case III + *M* and + V Cont. Girder.	One Arm Loaded.	Both Arms Loaded.	Case V + *M* and ± *V* Simple Span.	II and III for *Max.* + *M* and + *V*.	II and IV for Reversal.	I and IV or V for *Max.* − *M* and − *V*.	I and V for Reversal.
(1)	(2)	(3)	(4)	(5)	(6)	(7)	(8)	(9)	(10)	(11)
a b c	− 22,200	+ 55,300	+ 237,800	− 32,700		+ 270,900	+ 293,100	+ 22,600	− 22,200	+ 248,700
c d e	− 138,300	+ 67,500	+ 326,900	− 85,700		+ 412,500	+ 394,400	− 18,200	− 138,800	+ 273,700
e f g	− 316,000	− 15,650	+ 81,600	− 126,500		+ 210,600	+ 66,000	− 142,100	− 316,000	− 105,400
B C D	+ 69,100	− 75,400	− 326,200	+ 61,100		− 388,500	− 401,600	− 14,300	+ 69,100	− 319,400
D E F	+ 219,600	− 27,100	− 234,000	+ 107,800		− 343,500	− 261,100	+ 80,700		− 123,900
F G	+ 385,000	+ 76,300			+ 237,300			+ 313,600	+ 622,300	
a B	+ 33,200	− 85,400	− 360,300	+ 48,400		− 406,000	− 445,700	− 37,000	+ 33,200	− 372,800
B c	− 72,000	+ 29,300	+ 173,200	− 42,300		+ 230,700	+ 202,500	− 13,000	− 72,000	+ 158,600
c D	+ 112,700	+ 5,100	− 99,800	+ 105,500		− 126,700	− 94,700	+ 110,600	+ 112,700	− 14,000
D e	− 143,700	− 52,900	+ 37,000	− 193,700	− 196,800	− 169,700	− 15,900	− 249,700	− 340,500	− 313,400
e F	+ 174,200	+ 89,800	− 11,450	+ 311,700	+ 334,600	+ 278,300	+ 78,400	+ 424,400	+ 508,800	+ 452,500
F g	− 119,600	− 95,200			− 400,800	− 369,800		− 496,000	− 520,400	− 489,400
G H	+ 375,000	+ 73,400			+ 204,300			+ 277,700	+ 579,300	
g h	− 375,000	− 73,400			− 204,300			− 277,700	− 579,300	
G g	− 90,000	− 17,600			− 55,400			− 73,000	− 145,400	

77. True Reactions for Trusses Partially Continuous over Four Supports.—The method of redundant members is applied to this type of truss in the same way as for the two-span bridge, Art. 63. Consider R_1 as redundant. Then with this support removed the other reactions are determined by statics. For any load P on the first span these reactions are given by eqs. (15)–(17). For a load P on the third span, $R_2 = 0$ and R_3 and R_4 are the same as for a simple span. The stresses S' of eq. (1), Art. 63, are thus readily determined, and likewise the stresses u due to a one-pound reaction at A. The value of R' is then given by eq. (1).

The graphical process may be employed in the same manner as in Art. 63. Where the spans are equal, as in Fig. 17, the two centre reactions may be taken as redundant and a displacement diagram drawn for a load of one pound placed at each of the points g and h, considering the truss supported at the two ends. From this diagram the deflection curve of the lower joints with respect to the ends a, n, may be constructed as in Art. 64. Taking the deflection at g and h equal to unity this becomes a reaction influence line and may be used directly for constructing influence lines in the same manner as in Fig. 10. Such a construction has been carried out for Fig. 17, and Fig. 18 shows the reaction curve and the influence lines plotted thereon, for moments at c and f, and for V. comp. of stress in $B\,c$ and $e\,F$. The dotted line is the reaction line calculated by the beam formulas of Art. 75. The diagram shows clearly the error involved in the use of the usual formulas. It amounts, for example, to a maximum of 4.6 per cent for moment at c and 5.6 per cent for stress in $B\,c$.

The scale of the influence diagram for moments is found by multiplying the ordinate by $a/2$ as in Art. 67, where a is the distance of the moment centre from the left end. The correctness of the construction is shown as follows: Consider any moment centre E, Fig. 19, and a load P_1 distant $k\,l$ from A. Let M_2 = moment at B due to this load. Then

$$R_1 = P_1\,(1 - k) - \frac{M_2}{l} \text{ and}$$

$$M_E = R_1\,a = \left[P_1\,(1 - k) - \frac{M_2}{l}\right] . a. \quad . \quad . \quad . \quad (a)$$

Now if a second load P_2 be applied on the second span, distant $k\,l$

from D, the moments at B and C will be double their value for a single load. By the graphical analysis above given the ordinate $ff' \times P$ is the value of R_2 and R_3 for these two loads. The value of R_1 is $P\ (1 - ff')$, and the moment at B for the two loads $= R_1\, l$

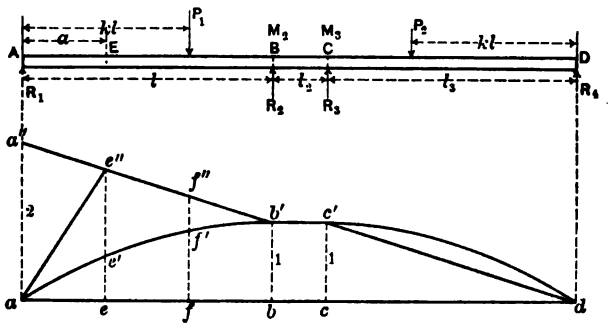

FIG. 19.

$- P\,(l - k\,l) = P\ (1 - ff')\ l - P\ (l - k\,l)$. For a single load the moment is one-half of this, or $M_2 = \dfrac{P_1\,(1 - ff')\,l - P_1\,(l - k\,l)}{2}$. Substituting in (a) and reducing we then have

$$M_E = P_1\,[2 - k - ff']\,a/2. \quad . \quad . \quad . \quad . \quad (b)$$

The ordinate $f'f''$ is equal to $(2 - k - ff')$, hence for unit loads the moment $M_E = f'f'' \times \frac{a}{2}$ as already stated. For shear, the ordinates are to be multiplied by ½, and for Vert. comp. web stress in Fig. 17 the factor is $\frac{1}{2} \times \frac{s}{t}$, where s = distance of point of intersection of chords to the left of a and t = distance from this intersection to the foot of the diagonal in question. (See Part I, Art. 162.)

Where the spans are unequal it is simpler to draw the displacement diagram for unit load at one end, as a, and from this construct the deflection diagram for points b and c with respect to a line joining a and d. The resulting diagram may be used in all respects as shown in Fig. 18.

78. Rim-bearing Turntable; Four Supports.—*Equal Moments at*

the Centre Supports.—Fig. 20.—In this the two triangular frames *B H C* and *C I D* support the truss by means of the short links *F H* and *G I*. The portions *B C* and *C D* of the frames are a part of the lower chord of the bridge. The point *C* is common to both frames. The inclinations of the members *B H*, *H C*, *C I*, and *I D* are such that under maximum loads at *H* and *I* the supports *B*, *C*, and *D* are equally

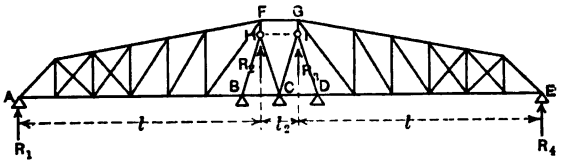

FIG. 20.

loaded. This arrangement brings the weight on the turntable uniformly distributed over six points. These points can be spaced equal distances apart on the turntable. Under all conditions, the moments at the two centre supports *F* and *G* are always equal. The analysis will then be the same as in Art. 74.

79. Lift Swing Bridges.—Various devices have been suggested whereby the bridge may be made continuous when being opened and two simple spans when closed. Fig. 21 shows a form in which, when the bridge is to be swung, the supports at *B* and *C* are lifted far enough to bring the links *E F* and *F G* into action and to raise the ends *A* and *D*

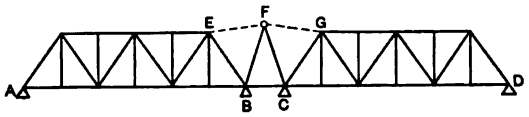

FIG. 21.

from their supports. All the weight is then at the centre and the bridge is swung on a centre-bearing pivot. When closed, and the supports *B* and *C* lowered, the links *E F* and *F G* are under no stress. The analysis then consists in finding the dead-load stresses when open, as in the other forms, and the dead- and live-load stresses when closed, the bridge then consisting of two simple spans. Other forms designed

to accomplish this object employ toggle joints in the members $E F$ and $F G$, or at other points of the upper chord, whereby it is shortened and the ends of the span lifted free of the supports.

80. Double Swing Bridges.—In a few cases where the clear span required is large two swing spans have been arranged as shown in Fig. 22, giving a clear opening from C to E. When closed the ends at D are locked so that the cantilever ends are forced to deflect equally. Except for this connection the reactions and stresses would be deter-

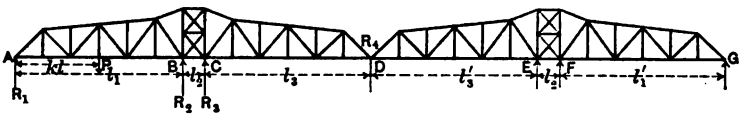

FIG. 22.

mined from statics, as in the cantilever bridge. The problem will be solved by determining the reaction at D for a single load placed at any point on one of the structures.

Suppose the joint at D not to exist. The structure $A B C D$ will then be statically determinate, and the reactions and deflection at any point may be determined by methods explained in Art. 77. Likewise the structure $D E F G$ will be statically determinate and its deflections may be found. Under these conditions let the following deflections be determined: (1) The deflection at D of the structure $A D$, for a single load P placed at any point of $A D$; (2) the deflection at D of the structure $A D$ for a load of one pound applied at D; and (3), the deflection at D of the structure $D G$ for one pound placed at D. Represent these deflections by δ'_n, δ'_d, and δ''_d, respectively. If the two structures now be connected the common point D will deflect a distance δ_n under the load P, which will be less than δ'_n by reason of the restraining action of the structure $D G$.

Let R_4 be the reaction at D, assumed upward on $A D$. Then we have, with respect to the structure $A D$,

$$\delta_n = \delta'_n - R_4 \delta'_d,$$

and with respect to the structure $D G$

$$\delta_n = R_4 \delta''_d.$$

Eliminating δ_n we have

$$R_4 = \frac{\delta'_n}{\delta'_d + \delta''_d}. \quad . \quad . \quad . \quad . \quad . \quad . \quad (22)$$

When δ'_n is downward then R_4 is positive, or upward on $A\ D$. The values of R_4 being known the other reactions are found by statics.

If the two structures are alike and symmetrical about D, then $\delta'_d = \delta''_d$ and we have $R_4 = \frac{1}{2}\frac{\delta'_n}{\delta'_d}$; but $\frac{\delta'_n}{\delta'_d}$ is the right reaction for a swing bridge, $A\ D$, on rigid supports, hence the reaction at D is one-half that of a structure on rigid supports.

For a symmetrical double bridge of the form considered in Art. 74, the value of R_4, for a single load on span $A\ B$ is, therefore,

$$R_4 = -\frac{1}{2} P \frac{l_1 (k - k^3)}{2 l_1 + 6 l_2 + 2 l_3} \cdot \frac{l_1}{l_3}, \quad . \quad . \quad . \quad . \quad (23)$$

and for a single load on span $C\ D$, distant $k\ l$ from D

$$R_4 = \frac{1}{2} P \left[(1 - k) - \frac{l_1 (k - k^3)}{2 l_1 + 6 l_2 + 2 l_3} \right]. \quad . \quad . \quad (24)$$

81. Stresses in Lateral Trusses.—The same general arrangement of lateral bracing is employed as in the ordinary through bridge. The loads upon the upper lateral system are transferred to the lower chord by portals at the ends and centre. Where the arrangement of the main truss provides a diagonal compression member in the panel next the centre, as member $h\ I$, Fig. 17, the portal is placed in the plane of this member and the upper laterals may be considered as terminating at I. The tower is then braced independently. The lower lateral system is complete from end to centre.

Owing to the relative flexibility of a portal frame the upper lateral system is little affected by the continuity of the structure and may be treated in the same manner as in a simple span $h\ n$, whether the bridge is open or closed. The lower lateral system requires consideration of continuity. The maximum shears near the end will occur for bridge closed and live load covering one span, corresponding to Cases II and III of the analysis for the vertical truss. For the shears near the centre the maximum may occur for bridge open, or for bridge closed and loaded with live load. In the first case the shears are determined

as in Case I, but to these should be added the shear due to one-half the load on the upper lateral system. For the case of bridge closed the shears are determined as for Case II and Case IV for main trusses.

The wind pressures assumed are generally on the basis of 50 lbs. per sq. ft. on truss alone when closed; and 30 lbs. per sq. ft. on truss when open, or on truss and train when closed and loaded.

Chord stresses resulting from wind loads should be considered where they increase the chord stresses in the main trusses.

CHAPTER III

CANTILEVER BRIDGES

82. General Arrangement of Spans.—A cantilever bridge is one in which one or more of its trusses are extended beyond their supports thus forming cantilever arms. The ends of these cantilever arms then furnish supports for other trusses. In the usual form each complete truss has only two supports and therefore the reactions and stresses are statically determined. Two general arrangements of spans are illustrated in Figs. 1 and 2. Fig. 1 illustrates the arrangement used in the case of numerous spans and Fig. 2 the more usual case of a crossing requiring one long span and two short ones. In Fig. 1 the structure consists of a series of main trusses $A\,C$, $D\,G$, etc., supported so as to form two cantilever arms. Then, resting upon these cantilever arms, are simple trusses $C\,D$, $G\,H$, etc. In Fig. 2 the main trusses are $A\,C$ and $D\,F$. They rest upon supports at A, B, E, and F, and are cantilevered at one end only. Obviously a combination of the single and double cantilevers may be the best arrangement in some cases. Fig. 3 represents the arrangement of the Niagara bridge, and Fig. 2 several Ohio River bridges. The Mississippi River bridge at Memphis consists of one double cantilever similar to $D\,G$, Fig. 1, one single cantilever like $A\,C$, Fig. 2, and two simple spans, one forming a shore span and the other a suspended span between the cantilevers. The Thebes bridge over the Mississippi River consists of two double cantilevers and three simple spans.

In Fig. 1, the spans $A\,B$ and $E\,F$ are called *intermediate* spans, the spans $B\,C$, $D\,E$, $F\,G$, etc., *cantilever* spans, or *cantilever arms*, and $C\,D$ and $G\,H$, *suspended* spans. In Fig. 2 spans $A\,B$ and $E\,F$ are called *anchor* spans instead of intermediate spans. The points A and F require anchorage to balance the loads on $B\,C$ and $D\,E$.

83. Advantages of the Cantilever Bridge.—The chief advantage of the cantilever type for spans of ordinary lengths is in the fact that certain spans can be erected without the use of falsework by building

out from the portion already constructed. Thus in Figs. 1 and 2, spans $A\,B$ and $E\,F$ would first be erected on falsework, as usual. This being done the cantilever arms $B\,C$ and $E\,D$ are constructed by building out from the points B and E. These arms being designed to act as cantilevers when in service their construction in this manner involves no unusual erection stresses. The points C and D being

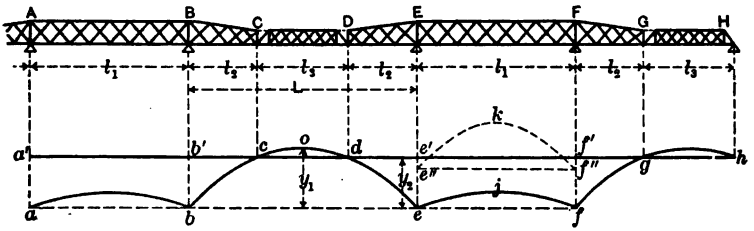

FIG. 1.

reached the suspended span is then built by continuing the same mode of construction from both sides until connection can be made at the centre. Temporary members are used at the ends C and D so that the two ends of the simple span may act temporarily as cantilevers. When connection is made at the centre these temporary members are disconnected so that the span $C\,D$ is free to turn at points C and D and

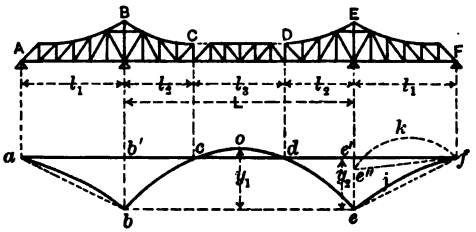

FIG. 2.

also has free horizontal motion at one end, thus becoming a simply-supported span. In the case of the suspended span the erection stresses need to be specially considered as the chord stresses are of different character from those which occur after erection.

The advantages in regard to erection which the cantilever type offers make it especially applicable to crossings where falsework is

not practicable, as at the Niagara gorge, or where the depth of channel or navigation interests makes it especially expensive or undesirable.

For spans of ordinary length (up to 500–600 feet), the cantilever type affords no economy over the simple truss, except in the case of expensive falsework, as noted above. For very long spans, however, where the dead load becomes relatively large, the cantilever type becomes the more economical, the advantages in this respect becoming greater the longer the span. A bridge of this type can thus be built of a span-length considerably greater than would be possible for a simple truss.

This gain in economy where the dead load is relatively large is due partly to the fact that the average moments for uniform loads are less than in the simple truss, and partly to the fact that the dead weight

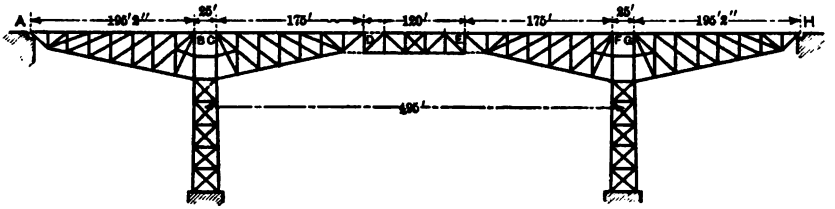

FIG. 3.

in the cantilever type is concentrated largely at points near the support, thus tending to reduce the moments still further. The wind-pressures on the structure will also be concentrated in the same favorable manner. On the other hand, the alternating stresses in the intermediate or anchor spans of the cantilever bridge tend to increase the amount of material required and so reduce the relative economy.

An unfavorable element of some importance is the large deflections of the cantilever ends as compared with those of a simple span. Short cantilever arms and long suspended spans are advantageous from this standpoint.

The distribution of moments in a cantilever bridge is much the same as in a continuous girder, but in the former the points of inflection are fixed by the hinges at the ends of the suspended spans. The variation in maximum moments throughout a cantilever structure is shown by

the moment diagrams of Figs. 1 and 2. The maximum moments in the suspended and cantilever arms occur for a full load on these spans. For a uniform loading the moment curve for the entire span $B\,E$ will be a parabola, $b\,c\,d\,e$, with centre ordinate $= y_1 = w\,L^2/8$, the same as for a simple beam of length L. The portion $c\,d$ gives the positive moments in the suspended span and the portions $b\,c$ and $d\,e$ the negative moments in the cantilever spans. For the intermediate or anchor arm $E\,F$, the maximum moments are generally the negative moments which occur when the live load extends over the suspended and cantilever arms. Were there no dead load on $E\,F$ the negative moment curve $e\,f$ would be a straight line; the effect of the dead load is to give to this line a flat curvature, the centre ordinate to which is the dead load positive moment at the centre of the span. The dotted curves $e''\,k\,f''$ (Fig. 1) and $e''\,k\,f$ (Fig. 2) represent the moments for span $E\,F$ fully loaded and show the maximum positive values.

The maximum moments in a series of simple spans, $B\,E$ and $E\,F$, are shown by the curves $b\,o\,e$ and $e''\,k\,f''$ or $e''\,k\,f$, measured from the lines $b\,e$ and $e\,f$ as axes. The relative chord sections required in the two types of structures is indicated to a certain extent by the areas of the respective moment diagrams. The sum of the moment areas for the span $B\,E$ is seen to be much less for the cantilever than for the simple span, but for the span $E\,F$ it is somewhat greater.

The moment areas of Figs. 1 and 2 depend to a considerable extent upon the relation between the span lengths $B\,E$, $E\,F$, and $C\,D$. The longer $B\,E$ as compared with $E\,F$ the greater will be the moment ordinate y_1, and the greater the negative moments in span $E\,F$, but if $E\,F$ is made too long then the positive moments therein become too large. Generally $E\,F$ is made from one-half to two-thirds of $B\,E$, if not determined by special considerations such as favorable pier locations, width of channel span, etc. Negative reactions in the type shown in Fig. 1 are to be avoided.

The spans L and l_1, being assumed as fixed, the length of the suspended span $C\,D$ for maximum economy may be investigated. The position of the ends of the span $C\,D$ fix the points of zero moment and therefore determine the location of the axis $b'\,e'$ of the moment diagram.

Let y_1 = central ordinate of parabola $b\,c\,d\,e$ and y_2 = ordinate at e. The sum of the positive and negative moment areas of the span $B\,E$ is equal to (area rectangle $b'\,b\,e\,e'$) − (area parabola $b\,c\,o\,d\,e$) + 2 × (area parabola $c\,o\,d$) $= y_2 L - \frac{2\,y_1\,L}{3} + \frac{4\,(y_1 - y_2)\,l_3}{3}$. Considering $e\,f$ a straight line, the moment area for span $e\,f = y_2\,l_1$ (includes both anchor spans of Fig. 2). We have also the relation $\frac{y_1 - y_2}{y_1} = \frac{l_3^2}{L^2}$. Substituting and differentiating with respect to l_3 we find for minimum sum of moment areas

$$l_3 = \tfrac{1}{2}\,(L + l_1).$$

Considering the span L only, it is found that for minimum moment areas $l_3 = \frac{1}{2}\,L$. The shears in the central span do not vary greatly for considerable variations in ratio of span lengths, but, on the whole, are less the shorter the suspended span.

84. Analysis.—The suspended span being a simple truss, its analysis for dead and live load requires no special consideration. Erection stresses need to be considered, these being calculated with each half-span treated as an extension of the cantilever arms. The stresses in the cantilever arm and in the anchor or intermediate span will be discussed in detail. It will serve to illustrate the entire problem to consider a structure of the form shown in Fig. 4.

a. The Cantilever Arm.—Consider the cantilever arm $D\,E$. The dead-load moments and shears are readily found by first getting the amount of load transferred to E from the suspended span and then taking shears, or moments of joint loads, on the right of any section. For live-load stresses the maximum moment and shear at any section in the arm $D\,E$ will result when the span $D\,F$ is fully loaded, although loads to the left of any given section do not affect the stresses of that section.

Influence lines for moment at I and shear in panel $I\,K$ are shown in Figs. 4 (*b*) and (*c*). The effect of a load unity on the span $E\,F$ is evidently proportional to the reaction caused at E, both as to moment and shear, hence the lines $F'E''$ are straight lines, with ordinates at E' equal to a and unity, respectively. As the load moves from E to I the resulting bending moment decreases uniformly to zero when the

load reaches I. The shear remains equal to unity until the load reaches K and then decreases to zero as the load crosses the panel $K\,I$. For maximum moment at I the criterion is the same as for moment at E in a simple beam $I\,F$. For shear, the same position of loads may be used as for shear.in the end panel of a simple truss extending from I to F.

b. The Intermediate Span.—The dead-load moments and shears due to loads on this span are the same as in a simple truss. To these must then be added the moments and shears due to the action of the

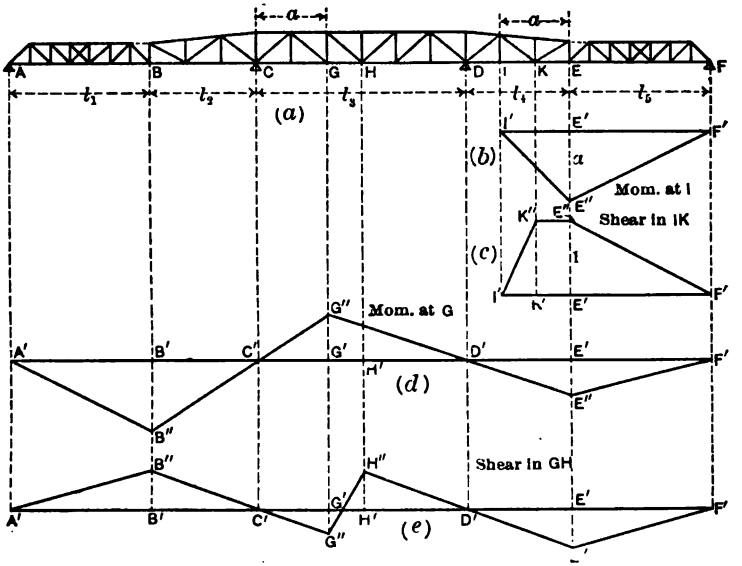

FIG. 4.

cantilever arms. Let M_D = moment at D, found from the cantilever arm $D\,E$, and M_C the moment at C, found from the arm $B\,C$. Then at intermediate points in $C\,D$ the moment due to the cantilevers will vary from C to D uniformly. Hence at a distance a from C the moment is $M_G = M_C + (M_D - M_C)\,\frac{a}{l_3}$. The same result will of course be obtained by calculating first the total reaction at C and taking moments of all forces on the left, about the given centre of moments.

The shear due to the cantilever loads will be constant throughout

span $C\,D$ and is to be added to the shears due to loads in $C\,D$. This constant shear is equal to the reaction at C minus the loads on the cantilever to the left. For symmetrical conditions this shear = o, and $M_C = M_D$.

For live-load moments and shears, construct the influence lines for moment at G and shear in panel $G\,H$.

Moment at G.—Fig. (*d*).—A load unity at E causes a negative reaction at C equal to $\frac{l_4}{l_3}$, and hence a negative moment at G equal to $\frac{a\,l_4}{l_3}$, which is laid off as $E'\,E''$ in Fig. (*d*). As the load moves to D or F, the moment at G decreases uniformly to zero and the influence line for this portion is $F'\,E''\,D'$. As the load moves from D to G, the moment increases from zero to a value of $\frac{a\,(l_3 - a)}{l_3}$ at G; beyond G the moment decreases again, becoming zero when the load is at C, then $\frac{l_2}{l_3}\,(l_3 - a)$ when at B, and finally zero for load at A. Since the ratio of $E''\,E'$ to $G''\,G'$ is equal to $\frac{l_4}{l_3 - a}$, it follows that $G''\,D'\,E''$ is a straight line. Similarly, $G''\,C'\,B''$ is a straight line. The influence line shows that for a maximum positive moment at G the span $C\,D$ should alone be loaded, and that for a maximum negative moment the spans $A\,C$ and $D\,F$ should be loaded.

If concentrated loads are used the criteria are evident from the diagrams. For positive moment it is the same as for moment at G in a beam $C\,D$, and for negative moments it is the same as for moment at B in a beam $A\,C$, and at E in a beam $D\,F$.

Shear in panel G H.—Fig. (*e*).—The portion $D'\,H''\,G''\,C'$ is the same as for a discontinuous span. Between D and F the shear in $G\,H$ is equal to the reaction at C caused by the load, and is negative, having a value of $\frac{l_4}{l_3}$ for unit load at E. When the load is between A and C the shear is positive and equal to the negative reaction at D. As before, the lines $B''\,C'\,G''$ and $H''\,D'\,E''$ are straight lines. The position of loads for a maximum positive or negative shear is evident from the diagram and also the exact positions of concentrated loads, if desired.

c. The Anchor Span.—If the portion $A\,C$ be omitted in Fig. 4 the span $C\,D$ becomes an anchor span. The influence lines are unchanged and the stresses will remain the same excepting those due to the cantilever arm $B\,C$, which are now zero. The maximum negative reaction at C is required in order to determine the anchorage which will be necessary.

85. *Equivalent Uniform Loads.*—In calculating stresses in large cantilever bridges some equivalent uniform load is usually employed. The influence lines will assist in arriving at a suitable value for such uniform load, as they show clearly the length of load or portion of structure which is significant. The method explained in Art. 173, Part I, will enable the equivalent load for any given system of concentrated loading to be determined for any case. Thus for negative moments throughout span $C\,D$, due to loads on $D\,F$, the equivalent load is that for moment at E in a span $D\,F$, or at a point $l_4/(l_4 + l_5)$ from the end in a span of length $(l_4 + l_5)$. Suppose $l_4 = 200$ feet and $l_5 = 300$ feet. Then $l_4/(l_4 + l_5) = 0.4$ and from Fig. 4, p. 53, the equivalent uniform load for Cooper's E-50 loading for the 0.4 point in a beam 500 feet long = 2,600 lbs. per ft. This loading will give exact result.

86. Divided Supports at the Piers.—For convenience of details the support at a pier is sometimes arranged as a double support, like the centre supports of a certain type of swing bridge (see Fig. 15, Chapter II). Such a form is used in the Niagara bridge, Fig. 3. The diagonals are omitted over the support so that no shear can be transmitted and the moments at each of the two points over the support are equal. The same arrangement may be made at both supports in the type of Fig. 1. In the calculations of stresses the panel over the support may be neglected and the calculations made exactly as for the case already explained. The moments throughout the structure will be the same and therefore also the shears. The load carried by each of the two supports will then be equal to the respective shears in the adjacent panels, plus any joint load applied at the supports. The sum of the two shears will be the total pier reaction as found in the other form.

87. Deflection of Cantilever Bridges.—The deflection of a cantilever truss may be calculated by the usual formula $\Delta = \Sigma \frac{S\,u\,l}{E\,A}$, or by the Williot diagrams. The end of the cantilever arm is subject to

a relatively large deflection, as its movement is due not only to the deformations of the members of the cantilever arm itself, but to the deformations also of the members of the anchor or suspended span which act to cause a change of angle in the truss at the pier. Some idea of the relative deflections of a simple span and a

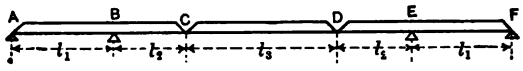

FIG. 5.

cantilever can be obtained by means of the deflection formulas for beams. Consider a load P placed at C, Fig. 5. The deflection of C relative to the tangent at $B = \Delta' = \frac{P l_2^3}{3 E I}$, and that of A is $\Delta'' = P \frac{l_2}{l_1} \cdot \frac{l_1^3}{3 E I}$. The effect of the distortion in $A B$ is to cause the tangent at B to change angle an amount equal to $\frac{\Delta''}{l_1}$, which causes an additional deflection of C equal to $\frac{\Delta''}{l_1} \times l_2$, hence the total movement of C is

$$\Delta' + \Delta'' \frac{l_2}{l_1} = \frac{P l_2^2 (l_2 + l_1)}{3 E I}.$$

A simple span of length $2 l_2$ will deflect at the centre a distance $\frac{P l_2^3}{6 E I}$. If $l_2 = l_1$, the deflection of the cantilever becomes $\frac{2 P l_2^3}{3 E I}$, or four times as much as a simple span of length $2 l_2$. Short cantilever arms and long suspended spans are therefore favorable from the standpoint of deflection. An especially unfavorable condition is such as occurs in the Niagara bridge, Fig. 3, where the deformation of the metal towers gives rise to still greater deflections.

88. Cantilever Bridge Without Suspended Span.—If the suspended span be omitted and the ends of the cantilevers connected, the structure becomes a partially continuous girder and is no longer statically determinate. For two such cantilevers the reactions are found as explained in Art. 80, Chapter II. For additional spans so connected the number

of redundant reactions becomes greater, requiring the solution of two or more general equations as illustrated in Art. 70. The Blackwell's Island bridge, New York City, is of this type.

89. Wind Stresses.—The wind pressure is carried to the supports by means of lateral trusses arranged according to the same cantilever system as the vertical trusses. The stresses are therefore determined in the same manner as explained in the preceding articles.

CHAPTER IV

ARCH BRIDGES

SECTION I.—GENERAL CONSIDERATIONS

90. An Arch as distinguished from a simply supported structure, is a beam or truss whose general form is that of a curve, or arch, and which is so supported on its abutments that horizontal as well as vertical motion is resisted. The reactions are, therefore, in general, not vertical but are inclined, the horizontal components of which act in a general direction toward each other and constitute the horizontal thrust of the abutment upon the arch.

In the case of roof arches the horizontal reactions are generally



FIG. 1.

supplied by means of a tie rod uniting the two supports, thus relieving the foundations of this duty.

91. Kinds of Arches.—Arches of timber or metal may consist of curved beams with solid webs and flanges, or they may be curved trusses with upper and lower chords and web members, either riveted or pin-connected.

With reference to the ordinary modes of support arches may be—

1st. Hinged at the abutments and at the crown.

2d. Hinged at the abutments and continuous throughout.

3d. Fixed rigidly to the abutments and continuous throughout.

Figs. 1, 2, and 3 illustrate three forms of the three-hinged arch;

Fig. 4 illustrates a two-hinged arch, and Fig. 5 an arch with no hinges. In Fig. 1 the arch is made in the form of a curved plate girder. Two-hinged arches are also often built in this manner. Fig. 2 is a roof arch in which the horizontal reactions are furnished by a tie rod. Occasionally such a tie rod is employed in bridge construction. Fig. 3 is a *spandrel braced* arch, the bracing occupying the entire space up to

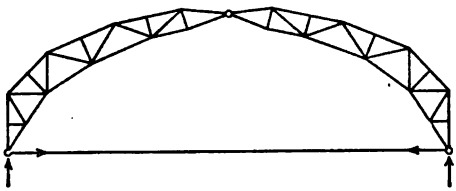

FIG. 2.

the roadway. This form is also well adapted to the two-hinged arch. Arches of one hinge, placed at the crown, have been constructed, but they are not advantageous and will not be considered in this work.

In Figs. 1, 4, and 5 the roadway is supported on the arch by means of vertical members, which serve merely to transmit the loads to the arch at certain joints or load points. Arch ribs as well as braced arches are generally loaded at certain load points only, as in the case of the simple



FIG. 3.

truss, or the plate girder with steel floor system. In certain cases it is expedient to suspend the roadway from the arch, as indicated in Fig. 4.

92. *Masonry Arches* of concrete or stone masonry are often built with two or three hinges, but generally with no hinge. While arches of brick or stone masonry can hardly be considered as arch ribs, those of solid or reinforced concrete may be classed as such. In any case the most satisfactory method of analysis of such structures is by the

so-called "elastic theory" as developed hereafter for the arch rib in general.

The masonry arch may support the load continuously through the medium of spandrel filling of earth or other material, or the roadway may be supported on piers or spandrel arches, as in the metallic bridge, thus concentrating most of the load at certain load points.

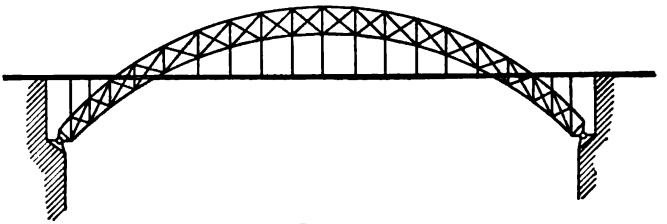

FIG. 4.

93. Loads and Reactions.—The methods of supporting the roadway of an arch bridge have been mentioned in Art. 91.

The amounts of the dead, live, and wind loads are fixed upon in the same manner as for other structures. For long-span structures the live load is generally assumed as a uniform load, but as arches are sometimes built of spans of very moderate length, concentrated loads may need to be considered. The use of influence lines enables this

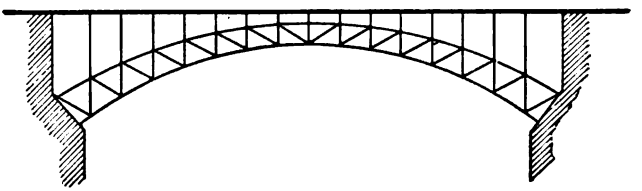

FIG. 5.

to be done with little more labor than is involved in the analysis for uniform loads.

The reactions are generally considered as resolved into two components, vertical and horizontal. In the arch with hinged ends these four components fully determine the reactions (Fig. 6). In the arch with fixed ends (Fig. 7), the reactions also include moments M_1 and M_2. In the three-hinged arch the four reactions may be determined

by the principles of statics, as explained in Part I, Chapter II, by reason of the fact that the moment is zero at the centre hinge. In the arch of two hinges there are four unknowns and in the arch without hinges, six. In both of these types the reactions cannot be determined by statics alone as they are dependent upon the flexibility of the arch and hence upon its form and dimensions. To solve these cases re-

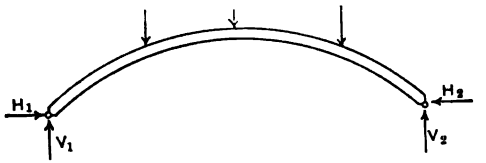

FIG. 6.

quires the consideration of the deformations of the structure as in the case of the continuous girder.

In the process of such an analysis, formulas may be developed for arches of solid beams of certain definite forms and proportions. These formulas may then be applied approximately to other forms of beams and even to trusses not too unlike the forms assumed. In this way an approximately correct design may be made. More exact stresses

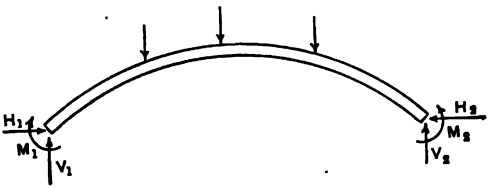

FIG. 7.

may then be found, if desired, by a calculation of the deformations of the actual arch, as in the case of the swing bridge.

For two-hinged spandrel-braced arches, such as shown in Fig. 3 but with two hinges only, a formula developed for a solid beam will not give satisfactory results, and resort must be had to the method of deflections or redundant members. Where, however, the truss is of small depth, as in Fig. 4 or 5, a suitable beam formula may often be applied with satisfactory results.

In the arch of two and of no hinges the reactions are modified by changes of temperature, since the structure is not free to expand. Also, in this form of structure, we can no longer neglect the effect upon the reactions of the changes in dimensions produced by the stresses themselves. It will be seen, therefore, that the analysis of these two types of arches involves not only the given loads but also the possible temperature changes and a close knowledge of the dimensions of the structure itself.

In the analysis of arches it is generally convenient to determine the reactions for a single (vertical or horizontal) load placed at any load point. The reactions being known the stresses in any member are readily found by the principles applicable to simple beams and trusses. Then by summation the reactions or stresses for any given loading may be found and thus the effect of dead and live loads determined.

94. Internal Stresses.—After the loads and reactions have been found the stresses in any part of the arch can be determined by the general methods applicable to simple beams and trusses. However, the presence of horizontal external forces and the special form of the structure, while involving no new principles, modifies somewhat the general formulas, methods, and definitions.

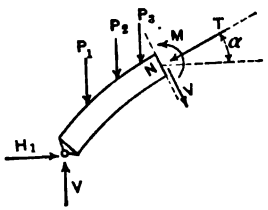

FIG. 8.

95. *The Arch Rib—(a) Algebraic Method.* —Consider an arch rib of constant depth, and let Fig. 8 represent the portion to the left of any section N taken at right angles to the axis. The external forces are supposed to be known.

Let ΣV = sum of the vertical components of the external forces on the left of the section;

ΣH = sum of the horizontal components of these forces.

ΣM = sum of the moments of the forces about the gravity axis at N.

α = inclination of axis at N to the horizontal.

The internal stresses at the section N are commonly expressed as a moment M, constituting a stress couple as in a simple beam, a thrust T, consisting of a direct compression uniformly distributed over the section, and a shear V, at right angles to the axis, as in a simple beam. Then, equating external and internal forces, we have in general

$$\left.\begin{aligned} M &= \Sigma M \\ T &= \Sigma V \sin\alpha + \Sigma H \cos\alpha \\ V &= \Sigma V \cos\alpha - \Sigma H \sin\alpha \end{aligned}\right\} \quad . \quad . \quad . \quad . \quad . \quad (1)$$

(*b*) *Graphical Method.*—The moment, shear, and thrust are readily obtained from the force and equilibrium polygons. Let *A b c d*, Fig. 9 (*a*), represent the equilibrium polygon drawn for the external forces

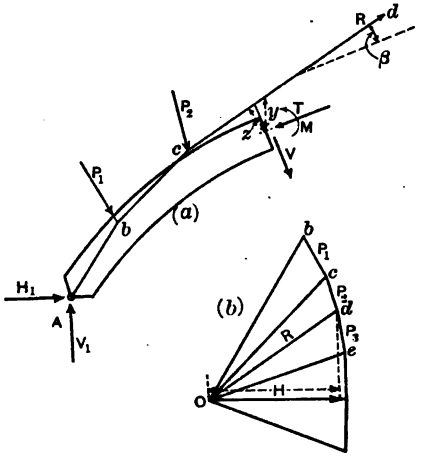

FIG. 9.

acting. Then R is the line of action of the resultant of all forces on the left of the section. Let β = angle between R and the axis at N and z = lever arm of R about the gravity axis of the section. We then have

$$\left.\begin{aligned} M &= R\,z \\ V &= R\sin\beta \\ T &= R\cos\beta \end{aligned}\right\} \quad . \quad . \quad . \quad . \quad . \quad . \quad . \quad . \quad (2)$$

The moment $R\,z$ is also equal to (Hor. comp. R) $\times\ y$; or if in Fig. (*b*) H = Hor. comp. R, we have also

$$M = H\,y. \quad . \quad . \quad . \quad . \quad . \quad . \quad . \quad . \quad (3)$$

When the loads are all vertical then H is the pole distance of the force polygon. Hereafter the loads will generally be assumed as vertical.

The values of M, V, and T having been found at any section the stress intensities are deduced as for the case of combined flexure and compression in straight beams.

If A = area of cross-section;

I = moment of inertia of cross-section;

y_1 and y_2 = the distances from the centroid of the section to extreme upper and lower fibres, respectively;

f_1 and f_2 = the corresponding fibre stresses, then, assuming M as positive when causing compression in the upper fibres, we have

$$\left.\begin{aligned} f_1 &= \frac{T}{A} + \frac{M y_1}{I} \\ f_2 &= \frac{T}{A} - \frac{M y_2}{I} \end{aligned}\right\} \quad \ldots\ldots\ldots \quad (4)$$

The distribution of shearing stress follows the same law as in a straight beam.

The application of these formulas involves a small error due to the curvature of the beam, which brings the centroid of stress slightly inside the centre of gravity of the section. This error is large only in the case of beams of very short curvature, such as rings and hooks. It is negligible in the case of most arches.

Moment Centres for Maximum Fibre Stresses.—In determining maximum total fibre stress, f_1 or f_2, and in studying the effect of moving loads, it is convenient to reduce eq. (4) to a different form. If r = radius of gyration, $= \sqrt{\frac{I}{A}}$, then eq. (4) may be written in the form

$$\left.\begin{aligned} f_1 &= \frac{T r^2 + M y_1}{I} \\ \text{and} \quad f_2 &= \frac{T r^2 - M y_2}{I} \end{aligned}\right\} \quad \ldots\ldots\ldots \quad (5)$$

Referring to Fig. 10, $M = Te$, hence

$$f_1 = \frac{T(r^2 + e y_1)}{I} = \frac{T\left(\frac{r^2}{y_1} + e\right) y_1}{I}.$$

Now $\frac{r^2}{y_1} + e$ is a length and $T\left(\frac{r^2}{y_1} + e\right)$ is a moment, which may

be called M'_1. Hence we have, $f_1 = \frac{M'_1 y_1}{I}$, in which M'_1 is equal to the thrust T, multiplied by the arm $\left(e + \frac{r^2}{y_1}\right)$. If now we lay off the distance $\frac{r^2}{y_1}$ *below* the gravity axis, fixing a point o_1, this point may be taken as the centre of moments for M'_1, for then $M'_1 = T\left(e + \frac{r^2}{y_1}\right)$. (This point o_1 is known as the *kern* point of the section.) A similar point *above* the neutral axis, distant $\frac{r^2}{y_2}$ therefrom, gives the centre of moments o_2 for the lower fibre stress. These moments may be called M'_2. Having the moments M'_1 and M'_2, the fibre stresses are

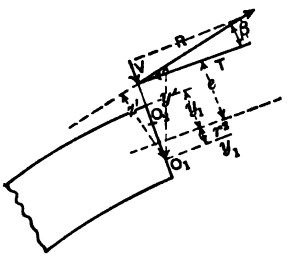

FIG. 10.

$$f_1 = \frac{M'_1 y_1}{I} \text{ and } f_2 = \frac{M'_2 y_2}{I}. \quad . \quad (6)$$

The extreme fibre stresses are proportional to the moments M'_1 and M'_2 and hence will be a maximum when these moments are a maximum. In finding maximum fibre stresses for moving loads it is therefore convenient to determine the maximum moments, using points o_1 and o_2 as moment centres. The values of the moments M' may be found in the same manner as for any other moment centre, using either T, R, or H in the equation, H being the horizontal component of R, as in Fig. 9 (*b*). Thus

$$M'_1 = T\left(e + \frac{r^2}{y_1}\right) = R\,z' = H\,y'. \quad . \quad . \quad . \quad (7)$$

If the beam is a plate girder and the moment of resistance of the web is neglected, or is taken account of by adding a certain fraction of its area to the flange, then the *kern* point or moment centre becomes the centre of gravity of the flange.

96. *The Braced Arch.*—(*a*) *Algebraic Method.*—If the arch is a truss then the stresses in the members are found most conveniently by moments; or, if the chords are parallel or nearly so, the web stress may also be found conveniently by shears as in a parallel or curved-

chord truss. Algebraically the stress in $A\,B$ (Fig. 11) $= M_D\,/t_1$; stress in $C\,D = M_A\,/t_2$. The stress in $A\,D$ may be found by taking moments about the intersection of $A\,B$ and $C\,D$, if convenient, or by an equation of horizontal or vertical components. Generally the co-ordinates of each joint, referred to horizontal and vertical axes, will be known, and hence horizontal and vertical projections of any

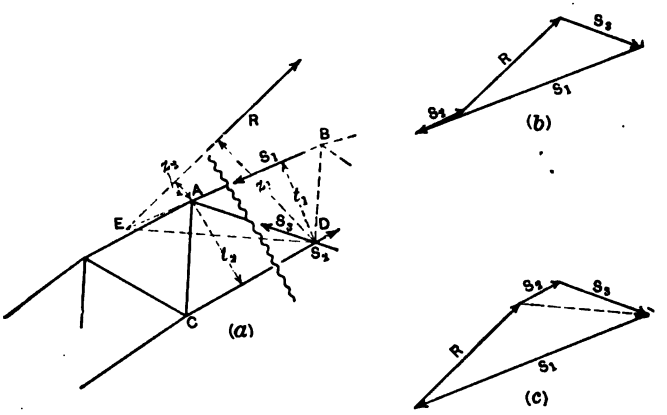

FIG. 11.

member can be readily found. The moments M, of the external forces on the left of the section, are also readily obtained from a summation of the moments of the loads and reactions in detail.

(*b*) *Graphical Method.*—The resultant R being known, the stresses may be found by various graphical methods (Fig. 11). The bending moment at $D = M_D = R\,z_1$, whence $S_1 = \dfrac{R\,z_1}{t_1}$; $M_A = R\,z_2$ and $S_2 = \dfrac{R\,z_2}{t_2}$. For stress in S_3 the force polygon for R, S_1, S_2, and S_3 may be drawn, as in Fig. 11 (*b*). Or, draw R to an intersection E, with one of the forces S_1. Then the resultant of R and S_1 must pass through the intersection D of the other two. This gives the direction of the resultant of R and S_1 and enables the three forces to be determined by the force polygon as shown in Fig. (*c*).

97. Advantages of the Arch Bridge.—If all the loads were fixed, the form of an arch could be so selected that the equilibrium polygon

of the forces would follow the axis of the arch throughout, as in Fig. 12. The only stresses then existing in the arch would be the thrust, and the design would be of maximum economy. Compared to a truss, such an arch rib would correspond somewhat to the upper chord, where the

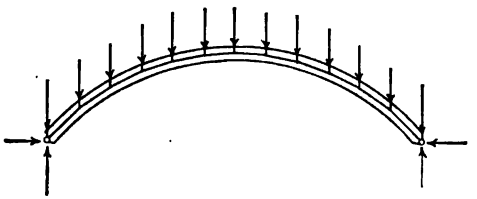

FIG. 12.

chord is curved just enoughto take all the shear. In the arch the lower chord is replaced by the thrust from the abutments. If the arch does not exactly fit the equilibrium or pressure line, as in Fig. 13, it will be

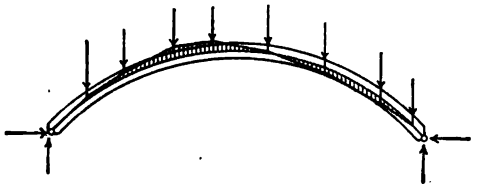

FIG. 13.

subjected to small bending moments, represented by the shaded areas. The truss, however, is subjected as a whole to moments as represented in Fig. 14, and the advantage of the arch is still large. When the live

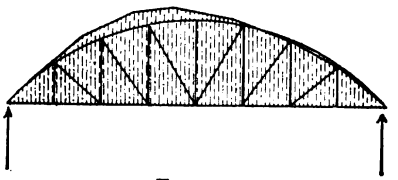

FIG. 14.

load is large as compared to the dead load, the moments which occur in the arch under partial loading also become large, and the advantages of the arch become still less, but the moments are yet on the average smaller than in the truss. Offsetting the advantage of such reduced

bending moments are the increased stresses in the piers or abutments, the serious modification of stresses which are caused by any slight settlement of supports (except in the three-hinged type), the stresses arising from temperature changes, and the large deflections under moving loads, with increased secondary stresses, as compared with deep trusses.

Arches are well adapted to high crossings, especially those of a single span. They can be constructed without falsework, in the same manner as cantilever bridges, and in many locations their form fits the contour of the ground very well, requiring a minimum amount of substructure. The use of arches at the Niagara gorge illustrates these points.

As compared to the suspension type of bridge the arch is more rigid and better suited for heavy railroad traffic for any but the longest spans. It is not so well adapted as the suspension bridge for very long spans, as the long compression rib of the arch cannot compare with a tension cable in certainty of design or economy of material. Deformations of a tension cable develop moments tending to resist further deformations, while deformations of a compression rib develop moments tending to increase still further such deformations.

98. Deflection of Curved Beams.—The equations of Arts. 1, 2, and 3 apply only to beams which are straight before bending. If a beam is curved in its unstrained condition, as in an arch rib, the formulas will be somewhat modified, due to the fact that the length of an element is no longer approximately equal to its horizontal projection.

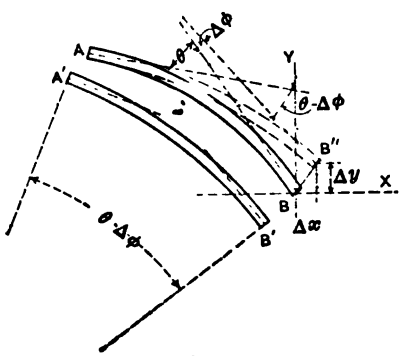

FIG. 15.

Let $A\,B$, Fig. 15, be any portion of a curved beam in its unstrained form. Suppose now that under the action of certain forces the beam is bent so that this portion is brought into the position $A'\,B'$. We wish now to find the movement of B and the tangent at B, with reference to A and the tangent at A, these two points, A and B, being any two points in the beam. This relative motion will be made apparent by

making A' coincide with A, and the tangent at A' coincide with the tangent at A. This new position is represented by the dotted outline $A\,B''$. The absolute movement $B\,B''$, now shown, is the relative movement required. The tangent at B has moved through an angle $\Delta\,\varphi$, making now an angle with the tangent at A of $\theta - \Delta\,\varphi$, θ being the original angle. The point B has also moved in space a distance $B\,B''$, the components of which motion, referred to any two rectangular axes with origin at B, will be called $\Delta\,y$ and $\Delta\,x$. The effect of flexure alone will be first considered, after which the effects of direct stress and temperature change will be taken account of.

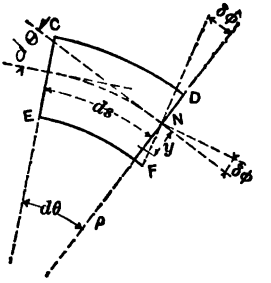

FIG. 16.

99. *Angular Change,* $= \Delta\,\varphi$. Let $C\,E\,F\,D$, Fig. 16, be an element of the beam, of length $d\,s$, whose end faces $C\,E$ and $D\,F$ are at right angles to the axis, and whose end tangents make an angle with each other originally equal to $d\,\theta$. Let $\delta\,\varphi$ be the change in angle between end faces or end tangents due to bending. The change in length of a fibre at a distance y from the neutral axis will be equal to $y\,\delta\,\varphi$, and the corresponding stress per unit area will be equal to $f = E\frac{y\,\delta\,\varphi}{d\,s}$. If $d\,a$ is an element of area of the cross-section, the total moment of resistance of the beam is equal to $\int_F^D f\,d\,a\,y = \int_F^D E\,y^2\,d\,a\frac{\delta\,\varphi}{d\,s}$. But for any particular section, E and $\frac{\delta\,\varphi}{d\,s}$ are constant; and if M is the bending moment at the section, taken about the axis N, and I is the moment of inertia of the section, we have

$$M = E\frac{\delta\,\varphi}{d\,s}\int_F^D y^2\,d\,a = E\,I\frac{\delta\,\varphi}{d\,s},$$

from which we have

$$\delta\,\varphi = \frac{M\,d\,s}{E\,I}, \quad . \quad . \quad . \quad . \quad . \quad . \quad . \quad . \quad (8)$$

and in Fig. 15,

$$\Delta\,\varphi = \int_A^B \delta\,\varphi = \int_A^B \frac{M\,d\,s}{E\,I}. \quad . \quad . \quad . \quad . \quad . \quad (9)$$

It has been assumed that the curvature of the beam is large as compared to the width $D F$ so that the length of all fibres of an element $d s$ may be assumed equal. For beams of very short curvature, as in the case of hooks, machine frames, etc., this assumption cannot be made.

Note that eq. (9) reduces to eq. (3) of Chap. I, if $d s$ is replaced by $d x$.

100. *Components of Deflection,* $= \Delta y$ and Δx.—Let $A C D E B$, Fig. 17, represent the axis of the unstrained form of the beam, and $A C D' E'' B''$ the strained form $A B''$, of Fig. 15. Now conceive the beam to pass into its strained form by the successive bending of each $d s$ in turn. The bending of the element $A C$ through the angle $\delta \varphi$ causes the portion $B C$ to turn through the same angle $\delta \varphi$ about C as a centre, with radius u, the point B moving to B' through a distance δv, having the components δy and δx. Then from the bending of $C D'$ the point B' moves to B'', etc. If x and y are the co-ordinates of any point C, origin at B, we have, by similar triangles,

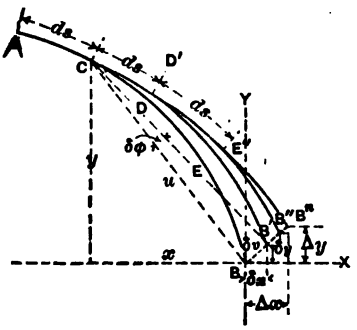

FIG. 17.

$$\frac{\delta y}{\delta v} = \frac{x}{u} \text{ and } \frac{\delta x}{\delta v} = \frac{y}{u}.$$

Solving for δy and δx and substituting for δv the value $u \delta \varphi$, we have

$$\delta y = x \delta \varphi \text{ and } \delta x = - y \delta \varphi.$$

Substituting the value of $\delta \varphi$ from eq. (8), we have

$$\Delta y = \int \delta y = \int_A^B x \delta \varphi = \int_A^B \frac{M x d s}{E I}, \quad . \quad . \quad . \quad (10)$$

and

$$\Delta x = \int \delta x = - \int_A^B y \delta \varphi = - \int_A^B \frac{M y d s}{E I}. \quad . \quad (11)$$

Equations (9), (10), and (11) are the fundamental equations em-

ployed in the analysis of arch ribs of steel and in the elastic theory of masonry arches. These formulas are also used for approximate analysis of trussed arches, in the same manner as the formulas for the solid continuous girder are used for continuous trusses. The deformation due to shear is negligible in the case of the solid beam, but is of importance in the case of the truss unless the depth be relatively small.

Equations (10) and (11) can readily be derived directly from the general formula for the deflection of a beam given in Art. 214, Part I. For a curved beam the formula would be $\Delta = \int \frac{M\,ds}{EI} \cdot m$, in which m = bending moment for a one-pound load applied at the point whose deflection is desired. For Δx the unit load would be applied at B and acting horizontally. The value of m would be equal to y, hence $\Delta x = -\int \frac{M\,ds}{EI} \cdot y$, Δx being negative. Likewise $\Delta y = \int \frac{M\,ds}{EI} \cdot x$.

101. *Effect of Direct Stress on the Values of* $\Delta\varphi$, Δy and Δx.— Arch ribs are generally subjected to combined compression and bending. In the foregoing analysis the effect of bending alone has been considered; we will now determine the effect of the direct compression upon the form of a curved rib.

Suppose the element $C\,D$, Fig. 18, represent any element subjected to the thrust T, applied at the gravity centre and producing a uniform compressive stress f per unit area. As a result of this stress all the fibres will be shortened a proportionate amount and $C\,D'\,F'\,E$ may represent the deformed element. The distortion $N\,N' = \frac{f}{E}\,ds$. Accompanying the longitudinal shortening $N\,N'$ there will be a slight expansion transversely, but this will be very small and will be neglected. The width $C\,E$ will therefore be unchanged and hence the radius and centre of curvature of the arch at this point will remain unchanged.

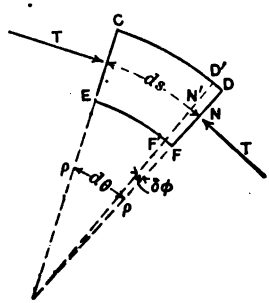

FIG. 18.

If ρ = radius of curvature of the axis then we have

$$\delta\varphi = \frac{f}{E} \cdot \frac{ds}{\rho}, \quad \ldots\ldots\ldots \quad (12)$$

and for the entire rib between any two sections A and B, as in Fig. 15,

$$\Delta \varphi = \int_A^B \frac{f\,ds}{E\rho}. \quad . \quad . \quad . \quad . \quad . \quad . \quad . \quad (13)$$

The components of the motion, Δx and Δy, are determined as follows: Suppose in Fig. 19 each element ds is shortened by the amount $\frac{f}{E}\,ds$. The shortening of the element AC affects the movement of B in two ways, (1) by the direct shortening of the rib and (2) by the change of angle $\delta\varphi$ produced. The first causes a shortening in the value of dx equal to $\frac{f}{E}\,ds\cos\alpha = \frac{f}{E}\,dx$, and in the value of $dy = \frac{f}{E}\,ds\sin\alpha = \frac{f}{E}\,dy$. The change of angle $\delta\varphi$ causes a movement of B determined as in Art. 99. The x-component $= \delta x = -y\,\delta\varphi$ and the y-component $= \delta y = x\,\delta\varphi$. Substituting the value of $\delta\varphi$ from eq. (12), we have for the total movement due to the shortening of the element AC,

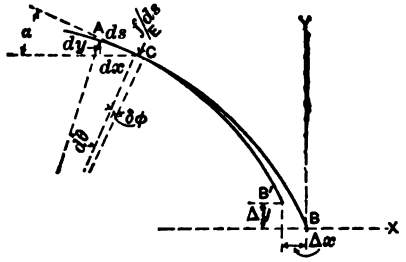

FIG. 19.

$$\left.\begin{aligned} \delta y &= \frac{f}{E}\,dy + \frac{f x\,ds}{E\rho} \\ \text{and} \qquad \delta x &= \frac{f}{E}\,dx - \frac{f y\,ds}{E\rho} \end{aligned}\right\} \quad . \quad . \quad . \quad . \quad . \quad (14)$$

Integrating between A and B we have finally

$$\left.\begin{aligned} \Delta y &= \int_A^B \frac{f\,dy}{E} + \int_A^B \frac{f x\,ds}{E\rho} \\ \Delta x &= \int_A^B \frac{f\,dx}{E} - \int_A^B \frac{f y\,ds}{E\rho} \end{aligned}\right\} \quad . \quad . \quad . \quad . \quad (15)$$

The origin is at B and x is measured positively toward the left.

102. *Effect of Temperature Changes.*—Let ω = coefficient of expansion and t = change of temperature, an increase of temperature

being called plus. An increase of temperature throughout the arch of t degrees will cause a proportionate increase of dimension, each ds being increased by $\omega t\, ds$. The x- and y-components will be increased by the amounts $\omega t\, dx$ and $\omega t\, dy$ respectively, and hence for any portion AB of a beam (Fig. 15),

$$\Delta x = -\omega t \int_A^B dx \text{ and } \Delta y = -\omega t \int_A^B dy. \quad . \quad . \quad (16)$$

The angle θ will not be affected.

103. *Total Values of* $\Delta\varphi$, Δy *and* Δx.—Combining the results Arts. 99–102, we have for the total movement of B, due to loads and temperature change

$$\Delta\varphi = \int_A^B \left[\frac{M\,ds}{EI} + \frac{f\,ds}{E\rho}\right] \quad . \quad . \quad . \quad . \quad . \quad . \quad . \quad . \quad . \quad (17)$$

$$\Delta y = \int_A^B \left[\frac{M\,x\,ds}{EI} + \frac{f\,dy}{E} + \frac{f\,x\,ds}{E\rho} - \omega t\, dy\right] \quad . \quad . \quad (18)$$

$$\Delta x = \int_A^B \left[-\frac{M\,y\,ds}{EI} + \frac{f\,dx}{E} - \frac{f\,y\,ds}{E\rho} - \omega t\, dx\right] \quad . \quad (19)$$

104. Application of Deflection Formulas to Arches.—In an arch of two hinges each part is, in general, subjected to bending moments and direct stresses, and therefore the arch is distorted at all sections. While

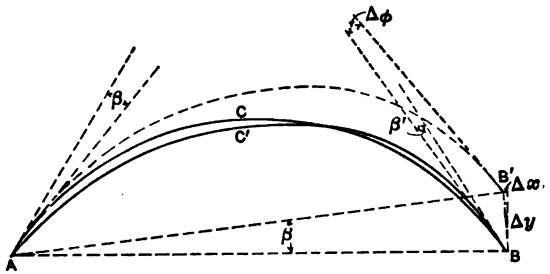

FIG. 20.

the end points remain in a fixed position the end tangents do not, each one turning more or less about the hinge. In Fig. 20 let the line $A\,C\,B$ represent the initial form of the arch axis and the line $A\,C'\,B$ the bent form under load. The tangent at A has turned through an angle β and at B through some other angle β'. To represent the motion of B

relative to the tangent at A the arch may be rotated about A through the angle β until the bent form coincides at that point with the original position. The movement at B is now correctly shown and is from B to B'. The values of Δy, Δx, and $\Delta \varphi$ at B' are given by the formulas of the preceding articles, but we are as yet unable to calculate these as the reactions and stresses remain undetermined.

Now Δx is a small quantity as compared to Δy, which is itself small as compared to the dimensions of the truss. Hence we may place $\Delta x = 0$ and therefore from (19) we have

$$\Delta x = \int_A^B \left[-\frac{M y ds}{EI} + \frac{f dx}{E} - \frac{f y ds}{E\rho} - \omega t dx \right] = 0. \quad . \quad (20)$$

This equation of condition, together with the three equations of statics, supplies the four equations necessary for the determination of the reactions for a two-hinged arch.

If the supports are not fixed, as in the case where a tie rod is used,

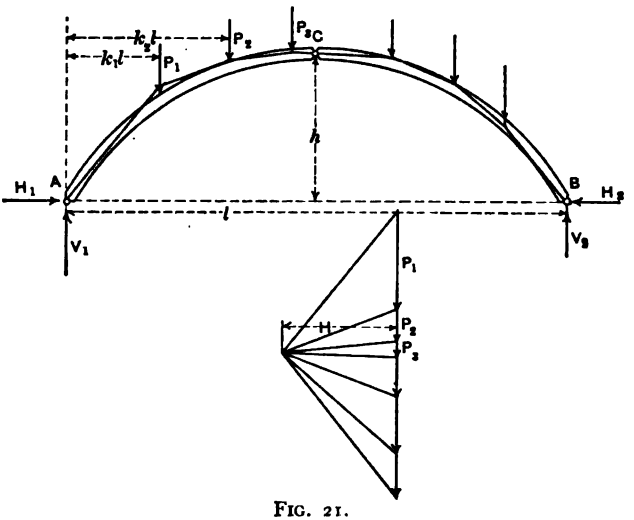

FIG. 21.

then Δx is not zero but is equal to the elongation of the tie rod under the stress H. Δx is to be assumed as positive when corresponding to a *shortening* of the arch.

For arches with fixed ends the values of both Δx and Δy are zero, and also the total change in angle, $\Delta \varphi$, from A to B, is zero. Hence

in eqs. (17), (18), and (19) the right-hand members reduce to zero, giving three condition equations. These, with the three equations of statics, enable the six unknown elements of the reactions in this case to be determined.

105. *Application to Trussed Arches.*—The beam formulas above developed may be applied approximately to trusses, as was done in the case of continuous girders and trusses. In many cases, however, the results thus obtained are not sufficiently accurate and recourse must be had to the method of redundant members whereby due account is taken of the deformation of the truss as actually built.

SECTION II.—ARCHES OF THREE HINGES

106. Reactions and Stresses for Dead Load.—The reactions for the three-hinged arch for any given loading are fully determined by statics, as explained in Chap. II, of Part I. A summary of the equations as applied to vertical loads will be here given. Fig. 21 shows an arch of three hinges supporting vertical loads. A and B are at the same level. Taking moments about B we have at once

$$V_1 = \Sigma P (1 - k). \quad . \quad . \quad . \quad . \quad . \quad . \quad . \quad (1)$$

Likewise, with A as moment centre

$$V_2 = \Sigma P k. \quad . \quad . \quad . \quad . \quad . \quad . \quad . \quad . \quad (2)$$

Then with C as moment centre, considering only the structure $A\,C$ (the moment at C being zero), we have

$$V_1 \frac{l}{2} - \Sigma_A^C P \left(\frac{l}{2} - k\,l \right) - H_1 h = 0,$$

whence

$$H_1 = \frac{l}{2h} \left[V_1 - \Sigma_A^C P (1 - 2k) \right], \quad . \quad . \quad . \quad (3)$$

also

$$H_1 = H_2 \quad . \quad . \quad . \quad . \quad . \quad . \quad . \quad . \quad (4)$$

whence all reactions become known.

Graphically, the reactions are determined by constructing an equilibrium polygon which shall pass through the hinges, A, C, and B, as shown in Fig. 21. See also Art. 45, Part I. In the manner there

described the dead-load reactions may be found at once, and thence the dead-load stresses either algebraically or graphically. (See Art. 60, Part I, for example of the graphical method applied to a roof-arch.) In the case of a trussed arch a stress diagram is the most expeditious way of determining dead-load stresses.

107. Reactions for a Single Load.—Let $A\,B\,C$, Fig. 22, represent a three-hinged arch of span l and rise h. P is any load, distant $k\,l$ from the left end.

(*a*) *Graphical Method.*—The equilibrium polygon is constructed by drawing $B\,C$ to intersect the load vertical at i and drawing $A\,i$.

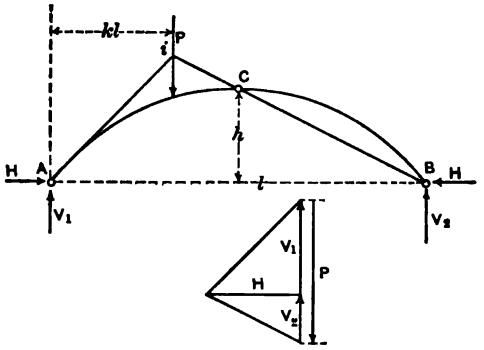

FIG. 22.

The force polygon determines V_1, V_2, and H. For a load on the right half, the left reaction line would pass through A and C.

(*b*) *Algebraic Method.*—As in Art. 106, we have

$$V_1 = P\,(1 - k). \quad . \quad . \quad . \quad . \quad . \quad . \quad . \quad . \quad . \quad (5)$$

$$V_2 = P\,k. \quad . \quad . \quad . \quad . \quad . \quad . \quad . \quad . \quad . \quad . \quad (6)$$

For a load on $A\,C$,

$$H = \frac{V_2\,l}{2\,h} = \frac{P\,l}{2\,h}\,k. \quad . \quad . \quad . \quad . \quad . \quad . \quad . \quad . \quad (7)$$

For a load on $C\,B$

$$H = \frac{V_1\,l}{2\,h} = \frac{P\,l}{2\,h}\,(1 - k). \quad . \quad . \quad . \quad . \quad . \quad . \quad (8)$$

It will be seen that the values of V_1 and V_2 are the same as for a simple beam, and that H is the same for loads symmetrically placed on the two halves, or for k in (7) equal to $(1 - k)$ in (8).

108. Use of Reaction Lines to Determine Position of Live Loads for Maximum Stresses.—The nature of the stress produced in any member, by a load placed at any given point, can readily be determined from a study of reaction lines, constructed as explained in the preceding article. This information is sufficient to determine the position of live load for a maximum stress in any member. The method of influence lines is also well adapted for this purpose, and for the calculation of the stresses themselves. Both methods will be explained.

Let q, Fig. 23, be any section cutting three members of a braced arch of three hinges, A, B, and C. The centre of moments for $D\,E$ is

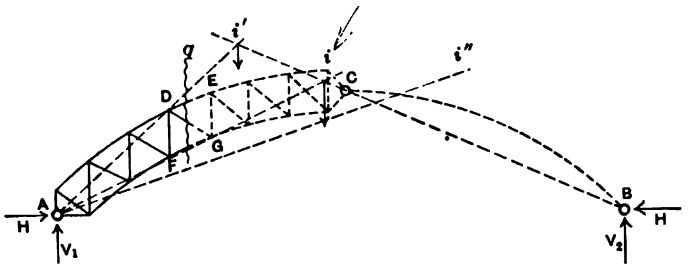

FIG. 23.

G, and a load at i, the intersection of $B\,C$ and $A\,G$, will cause no stress in $D\,E$, since the line $A\,G$ is the line of action of the abutment reaction at A, the only external force on the left of the section. For loads between i and B the left reaction line will pass below G, passing through C for loads on $C\,B$. The moment of the reaction at A, about G, will then be negative and cause tension in $D\,E$. For loads between i and E, inclusive, the reaction line from A lies above G, and therefore the stress in $D\,E$ will be compressive. For loads between D and A the only force on the right of the section is the reaction at B, acting in the line $B\,C$, which also causes compression in $D\,E$. Therefore for a maximum tension in $D\,E$ all joints from i to B should be loaded and for maximum compression all joints from A to i.

The centre of moments for $F\,G$ is at D, and from considerations similar to the preceding, it is found that the maximum tension and the maximum compression in this member occur when the load extends to the left and right, respectively, of point i'.

For the web member $D\,G$, draw $A\,i''$ parallel to $D\,E$ and $F\,G$, if

these members are parallel, or toward their intersection if not parallel. For all loads between G and B the reaction line from A lies above $A\ i''$, since this line never passes below C. Hence the component of the reaction perpendicular to $A\ i''$ (in case of parallel chords), or the moment of the reaction about the intersection of $D\ E$, $F\ G$, and $A\ i''$ (in case of non-parallel chords), produces tension in the member $D\ G$. For loads from D to A the right reaction, acting in the line $B\ C$, causes compression in $D\ G$. Hence for maximum tension in $D\ G$, $G\ B$ should be loaded, and for maximum compression $D\ A$ should be loaded. If $A\ i''$ should pass to the left of C, then all loads between its intersection with $B\ C$, and B, would cause compression in $D\ G$.

In the case of an arch rib the centres of moments are taken as explained in Art. 95, and in finding the load for maximum shear, the limiting line, corresponding to $A\ i''$, is drawn parallel to the flanges at the section considered.

109. Influence Lines for the Three-Hinged Arch.—For some purposes the use of influence lines is preferable to the method just explained. In the case at hand their construction leads at once to methods of calculating maximum stresses for concentrated loads which are as readily applied as in the case of simple trusses.

110. *Influence Line for H.*—Consider the arch of Fig. 24, with a single load P at any point D or D'. The value of H for loads on the left half is $\frac{P\ l}{2\ h}\ k$, and for loads on the right half is $\frac{P\ l}{2\ h}\ k'$. The influence line for H then consists of the two straight lines $A'\ C''$ and $C''\ B'$ of Fig. (*b*), the ordinate $C'\ C''$ being equal to $l/4\ h$.

111. *Influence Lines for Moment.*—Consider the moment at G for stress in $D\ E$. The value of this moment for a load on the right of the section is $V_1\ a - H\ y$, and for a load on the left it is $V_1\ a - P\ (a - k\ l) - H\ y$. Noting that the value of V_1 is the same as in a simple truss, it is seen that in all cases the moment at G, due to the vertical forces V_1 and P, is the same as in a simply supported truss, and that the total moment is equal to this moment, less the moment $H\ y$. Hence to construct the influence line for M_G we may first construct the influence line for moment at G' in a simple beam $A'\ B'$ (Fig. *c*), making $G'\ G'' = \frac{a\ (l - a)}{l}$ as in Art. 122, Part I. Then on

this same base construct a diagram $A' C'' B'$, in which $C' C'' = \frac{l}{4h} \cdot y$. The ordinate to this diagram at any point will then be $H y$, and the total bending moment at G, due to a load unity at any point, will be given by the ordinates of the shaded area between the lines $A' G'' B'$ and $A' C'' B'$. This shaded diagram is therefore the in-

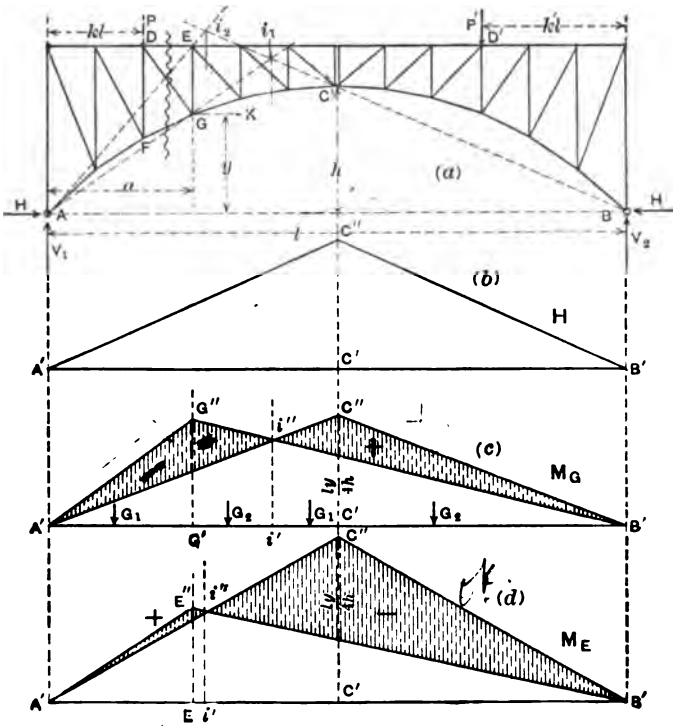

FIG. 24.

fluence diagram for moment at G. It is unnecessary to replot this diagram to a straight base as the shaded area gives all needed information.

Fig. (d) shows the influence diagram for moment at E for stress in $G K$. The diagram is the same as Fig. (c) excepting the ordinate $C' C''$, the value of y being now the ordinate to point E, which is equal to h plus length of center strut.

The points i'' in Figs. (c) and (d) are the critical points, correspond-

ing to the points i_1 and i_2 of Fig. (*a*). Loads placed in those verticals cause no moments at the respective moment centres. The influence areas indicate clearly the relative effect of loads on different parts of the arch. They can readily be used for calculating maximum stresses due to either uniform or concentrated loads, as in the case of simple structures.

112. *Criterion for Maximum Moment.*—The form of the influence lines of Figs. (*c*) and (*d*) gives at once the criterion for maximum moments, as in Arts. 123 and 134 of Part I. The influence areas are all triangular in form and hence the same criterion for maximum will apply as for moment in a simple beam of a length equal to the length of the triangular area in question. Thus for maximum ~~positive~~ negative moment at G the criterion is the same as for moment at G' in a beam $A'i'$ (Fig. *c*). Hence if the loads on the portions $A'G'$ and $G'i'$ be represented by G_1 and G_2 the criterion for maximum is

$$\frac{G_1}{A'G'} = \frac{G_2}{G'i'} = \frac{G_1 + G_2}{A'i'}. \quad . \quad . \quad . \quad . \quad . \quad . \quad (9)$$

The train should probably head toward the right. For the maximum ~~negative~~ moment, load $i'B'$, heading train toward the left, the criterion is

$$\frac{G_1}{i'C'} = \frac{G_2}{C'B'} = \frac{G_1 + G_2}{i'B'}. \quad . \quad . \quad . \quad . \quad . \quad . \quad (10)$$

It will be seen that the determination of the distances needed in eqs. (9) and (10) requires the fixing of point i' only, which can be done by the reaction lines shown in Fig. (*a*). The above method is equally applicable to arch ribs, using the proper *kern* point or flange centre for the moment centre.

113. *Influence Lines for Web Stress or Shear.*—Consider the stress in DG, Fig. 25. It will be convenient to construct the influence line for the vertical component of this stress. Produce FG to the intersection I. The stress in DG is found from the moments about I of the forces to the left (or right) of the section. For loads from G to B this moment $= V_1 s - Hy$, and Vert. comp. $DG = V_1 \frac{s}{t} - \frac{Hy}{t}$, where y = ordinate to moment centre I. And for loads from A to F, Vert. comp. $DG = V_2 \frac{l-s}{t} - \frac{Hy}{t}$. For unit load the influence

lines for $V_1 s/t$ and $V_2 (l - s)/t$ are given in Fig. (*b*) by the lines $A'' B'$ and $A' B''$. (These are the same as for web stress in a simple truss of the form shown.) Then, as in Art. 111, we may plot to the same base a diagram for $H y/t$, making the ordinate $C' C''$ equal to $l y/4 h t$. The shaded areas are then the influence areas for the ver-

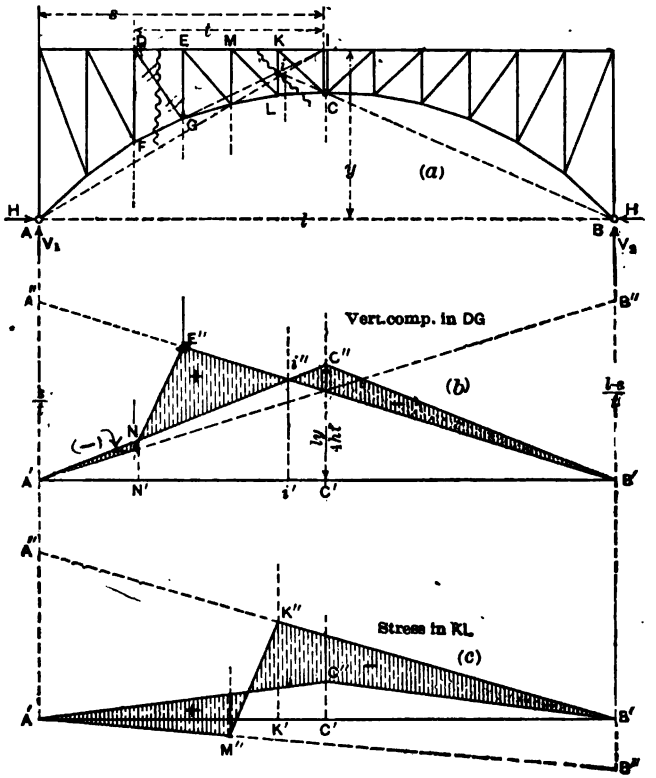

FIG. 25.

tical component in $D G$. The point i' is readily found also by the indicated construction in Fig. (*a*).

For maximum compressive stress in $D G$, the portions $A' N'$ and $i' B'$ should be loaded, and for maximum tension the portion $N' i'$. The criteria may be stated as for moment, but the question of separate loadings, or broken loads, for sections $A' N'$ and $i' B'$ requires special consideration.

Fig. (*c*) shows the influence diagram for stress in *K L*. Here it will not be convenient to get the intersection of the chords, but instead the method of shears may be used. The points *K″* and *M″* are determined by placing a unit load at *K* and then at *M* and calculating the stress in *K L* as for a simple span. Then for a unit load at *C* calculate the stress in *K L* due to the *horizontal force H* equal to $l/4\ h$. Plot this as *C″ C′*. This enables the complete diagram to be drawn.

In the rib or solid beam, Fig. 26, the shear for loads on the right of the section is $V = V_1 \cos \alpha - H \sin \alpha$, and for loads on the left it is $- V_2 \cos \alpha - H \sin \alpha$. The resulting influence diagram is shown in Fig. (*b*). The lines *A″ B′* and *A′ B″* are the same as for shear in a simple beam, multiplied by cos α, and the term $H \sin \alpha$ is given by the diagram *A′ C″ B′*.

114. *Influence Line for Thrust.*—The thrust, *T*, Fig. 26, is equal to $V_1 \sin \alpha + H \cos \alpha$, for loads on the right of the section, and $- V_2 \sin \alpha + H \cos \alpha$, for loads on the left. The influence diagram for the thrust is given in Fig. (*c*).

115. **Equivalent Uniform Loads for Three-Hinged Arches.**—The influences lines of Figs. 24 and 25 aid greatly in selecting a suitable equivalent uniform load. It will be noted that only a portion of the span is covered for maximum moments and that therefore the equivalent uniform load should be selected with reference to a span length considerably shorter than the arch span.

The special method of selection explained in Art. 174, of Part I, is directly applicable to this case. Thus for the maximum moment at *G*, Fig. 24 (*c*), the equivalent uniform load is that for moment at *C′* in the beam *i′ B′*. If, for example, *l* = 180 feet, then *i′ B′* = about 110 feet, *i′ c′* = 20 ft., and *i′ C′*/*i′ B′* = 0.18; hence the equivalent uniform load is that for moment at the 0.18 point in a beam 110 feet long. Referring to Fig. 4, p. 53, we find this to be 3,400 lbs. per foot for Cooper's E-50 loading. The maximum live-load moment at *G* is therefore equal to area *i″ C″ B′* × 3,400.

116. **Deflection of the Three-Hinged Arch.**—The methods of calculating deflections are the same as given in Chap. VII, Part I. Under full loads arches deflect less than simple trusses, but under partial loads the deflection at the quarter point may be much greater.

In applying the graphical method to the three-hinged arch, a

separate diagram must be drawn for each half in case of unsymmetrical loading. Then since all members in general change their direction the diagram will require correction, which must be made on the basis of fixed abutments and a hinge at the centre. As the construction of displacement diagrams is of special importance in the case of arches, such

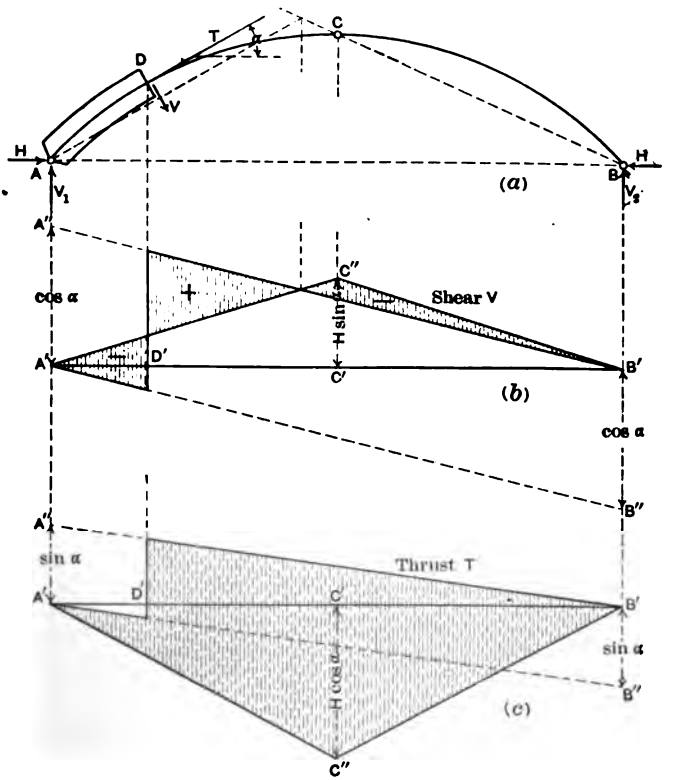

FIG. 26.

a diagram will be drawn for the arch shown in Fig. 27 (*a*), which is an outline of the arch bridge of the Chicago, Milwaukee and St. Paul Railway Company across the Menominee River, near Iron Mountain, Michigan.* The span length is 207 feet.

A load of 1,000 lbs. per joint will be assumed as applied on the left

* See *Engineering News*, Nov. 20, 1902.

half only, giving unsymmetrical conditions. The resulting stresses, determined graphically, are tabulated below, together with lengths and cross-sections of members and values of deformation times E, $= \frac{Sl}{A}$.

Member	Length l	Cross-Section A	Stress S	$\frac{Sl}{A}$
a b	276	27.2	− 910	− 9,200
b c	276	27.2	− 1,800	− 18,300
c d	276	24.6	− 2,560	− 28,700
d e	276	24.6	− 2,380	− 26,700
e F	153	31.2	− 2,650	− 13,000
A B	313	46.2	− 2,800	− 19,000
B C	310	38.0	− 1,760	− 22,800
C D	302	38.0	− 730	− 5,900
D E	240	38.0	+ 100	+ 800
E F	153	38.0	− 90	− 400
a A	624	40.7	− 2,560	− 39,300
a B	550	20.6	+ 1,810	+ 40,300
b B	476	32.4	− 2,080	− 31,300
b C	435	14.7	+ 1,400	+ 41,600
c C	336	23.5	− 1,600	− 22,800
c D	348	14.7	+ 970	+ 23,000
d D	213	19.8	− 910	− 9,800
d E	306	14.7	− 200	− 4,200
e E	132	19.8	+ 160	+ 1,100
F g	153	31.2	− 80	− 400
g h	276	24.6	− 70	− 800
h i	276	24.6	+ 480	+ 5,400
i j	276	27.2	+ 330	+ 3,300
j k	276	27.2	+ 150	+ 1,500
F G	153	38.0	− 2,660	− 10,700
G H	240	38.0	− 3,070	− 19,400
H I	302	38.0	− 3,050	− 24,200
I J	310	38.0	− 2,930	− 23,800
J K	313	46.2	− 2,620	− 17,700
g G	132	19.8	+ 20	+ 200
G h	306	14.7	+ 600	+ 12,600
h H	213	19.8	− 260	− 2,800
H i	348	14.7	− 180	− 4,400
i I	336	23.5	+ 100	+ 1,500
I j	435	14.7	− 260	− 7,700
j J	476	32.4	+ 200	+ 3,000
J k	550	20.6	− 250	− 6,700
k K	624	40.7	+ 210	+ 3,200

Fig. (*b*) is the displacement diagram for the left half, assuming *A a* to remain vertical; and Fig. (*c*) is the diagram for the right half, *K k* remaining vertical. It remains now to correct these diagrams on

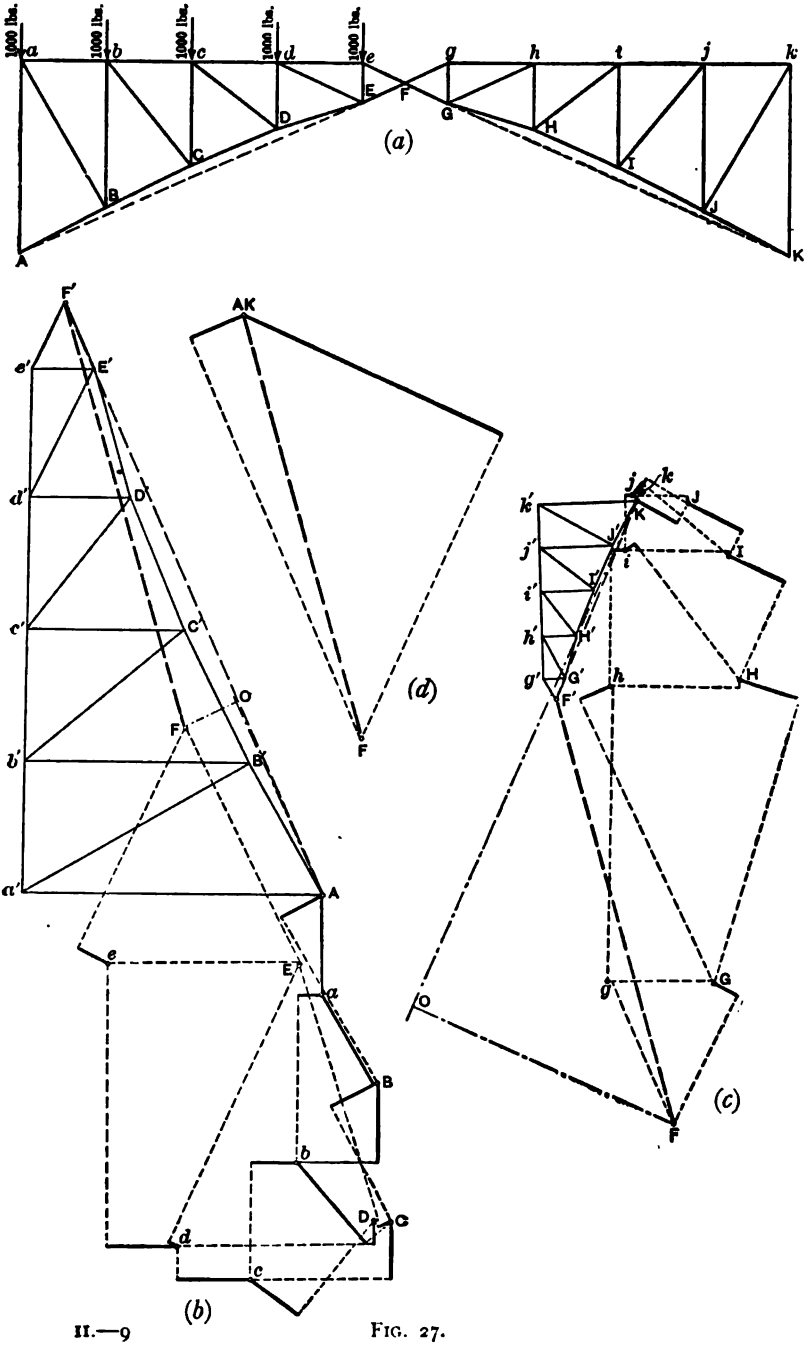
1000 lbs.
a
b
c
d
e
g
h
i
j
k
A
B
C
D
E
F
G
H
I
J
K
(a)
F′
e′
E′
d′
D′
c′
C′
O
F
b′
B′
a′
A
e
E
a
B
b
D
C
d
c
(b)
AK
F
(d)
j
k
k′
J
K
j′
J′
i
I
i′
I′
h′
H′
g′
G′
F′
h
H
g
G
O
F
(c)

FIG. 27.

the basis that the movement of the point F is determined by the deformation along the lines $A\,F$ and $F\,K$. The actual deformation of $A\,F$ is determined in Fig. (*b*) by drawing $A\,O$ perpendicular to line $A\,F$ of Fig. (*a*). The distance $F\,O$ is the deformation required; it is compression. Then likewise, in Fig. (*c*), the distance $F\,O$, from F to the line $K\,O$, is the true deformation of line $F\,K$ of Fig. (*a*). These deformations being known, a diagram, Fig. (*d*), assuming A and K to stand fast, determines the true movement of F, which is the distance $A\,F$. Then, in Figs. (*b*) and (*c*), the correction diagrams, shown by light full lines, are drawn, making $F\,F'$ in each one equal to $F\,K$ of Fig. (*d*). The true movement of any joint is then found as usual from Figs. (*b*) and (*c*), measuring from the correction diagram.

117. *Deflection Due to Temperature Changes.*—For a uniform change of temperature throughout the arch, all the members are affected proportionately and each half of the arch will be exactly similar to the

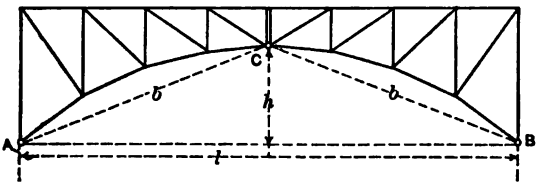

FIG. 28.

original form, but with all dimensions reduced or increased in the same ratio. From this condition the movement of the crown, or any joint, can readily be stated algebraically.

Consider the arch of Fig. 28. Let t = change of temperature, ω = coefficient of expansion, and Δ = rise of crown hinge C due to the change of temperature. The length b is increased by the amount $\omega\,t\,b$ which, since the span length is fixed, acts to raise point C. From the relation $h^2 = b^2 - \left(\frac{l}{2}\right)^2$ we have, by differentiation, $2\,h\,d\,h = 2\,b\,d\,b$, and hence $d\,h = d\,b\,\frac{b}{h}$. But for small movements $\Delta = d\,h$, and $\omega\,t\,b = d\,b$, hence we have

$$\Delta = \omega\,t\,\frac{b^2}{h} = \omega\,t\,h\left(1 + \frac{l^2}{4h^2}\right). \quad . \quad . \quad . \quad . \quad (11)$$

For other points the movement is readily deduced from that at C.

118. Stresses in Lateral Systems.—A complete lateral system for a three-hinged arch requires an arrangement of bracing as shown in Fig. 29 or in Fig. 30. The dotted lines indicate the planes in which diagonal bracing is required in order to give lateral rigidity. In Fig. 29 a complete upper lateral system is provided, transferring its load to points a and c_1 on the left and c_2 and b on the right. From these points

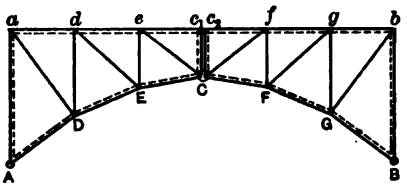

FIG. 29.

the loads are transferred by means of vertical transverse bracing to the point C and to the abutments at A and B. The upper laterals cannot be made continuous at the centre, as motion must be free at this point. The lower laterals extend continuously from A to B. In Fig. 30 the loads acting at the upper panel points are transferred at each panel by means of vertical transverse bracing to the lower lateral system, and thence to the abutments.

Generally, for the sake of added stiffness, transverse bracing is used at every panel and an upper lateral system also provided. In

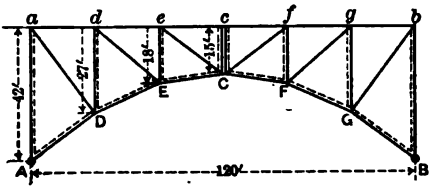

FIG. 30.

this case the loads will travel from the upper joints to the abutments along the two paths offered, in proportion to their rigidity. By reason of the large section of the lower chord, and the fact that the shortest path to the abutment is down the vertical and thence along the lower chord, it is economical and convenient to provide bracing along this line of travel sufficient to take most or all of the loads on the upper

joints. The upper laterals along the roadway should then be added for sake of increased rigidity and should be designed to carry one-third to one-half of the loads at the upper joints. The analysis of the several systems will be considered on this basis.

(*a*) *The Upper Lateral Truss.*—The stresses in the upper lateral truss are calculated as for a simple truss with supports at a and c_1, c_2 and b. Lateral forces applied in a plane above the lateral truss will cause an overturning moment, giving rise to vertical loads on the main trusses, as in the case of an ordinary bridge. These loads may be combined with other vertical loads developed by the transverse bracing and the lower laterals, as discussed later.

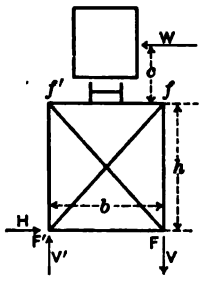

FIG. 31.

(*b*) *The Transverse Bracing.*—Fig. 31 represents the transverse bracing at any panel, and W the amount of the lateral panel load assumed as carried by the transverse bracing (the total upper panel load in Fig. 30), applied at a distance c above the top laterals. Then Hor. comp. $f'F = W$; $V = V' = W\frac{c+h}{b}$; $H = W$. Stress in $f'F' = W\frac{h+c}{b}$. The reactions V and V', reversed in direction, act as vertical loads upon the main trusses at F and F'. The reaction H is supplied by the lower lateral system.

If upper laterals are used then the transverse frames at c and b receive the loads from these laterals and are stressed the same as the end bracing in a simple-span deck bridge.

(*c*) *The Lower Lateral Bracing.*—The lateral forces acting at the several joints are equal to the lower joint loads, plus the lateral forces, if any, brought to the joints by the transverse bracing in the several panels. Having these lateral forces, the shears in the lateral system are found as for a simple truss of the same span. These shears give the lateral components of the web stresses. Since the diagonal members of the lower lateral system do not lie in a horizontal plane, the resultant of the diagonal stress and that of the lateral strut meeting at the same joint is inclined, this inclination being different at each joint. These resultants being determined they can in turn be resolved into horizontal

and vertical components in the plane of the main truss. The stresses in the main truss due to these forces, together with those due to the loads brought by the transverse bracing, are then found.

In the case of an arch rib, lateral bracing is usually inserted along both the top and bottom flanges. The lateral load brought down from the roadway together with that applied along the girder itself, may be assumed to be equally divided between the two systems of bracing.

EXAMPLE.—For illustration, the lower lateral stresses of Fig. 30 will be determined. Width between trusses = b = 16 ft. Suppose the lateral force acting along the top chord = 500 lbs. per lineal foot, applied 10 ft. above the plane of the upper chord, and the lateral force acting along the lower chord = 300 lbs. per lineal foot. The total lateral force acting at each joint, C, F, and G, including the load transferred by the cross-bracing = (500 + 300) × 20 = 16,000 lbs. The overturning effect at each panel causes vertical loads at the several panels as follows: At panel C, $(500 \times 20) \times \frac{25}{16} = 15{,}600$ lbs.; at panel F, $10{,}000 \times \frac{28}{16} = 17{,}500$ lbs.; and at G, $10{,}000 \times \frac{37}{16} = 23{,}200$ lbs. These forces act as downward loads on the leeward truss and upward loads on the windward truss.

Fig. 32 represents the lower lateral system, with lateral loads W, each equal

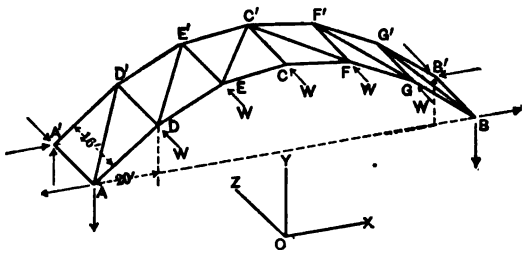

FIG. 32.

to 16,000 lbs. Tension diagonals are assumed. For convenience in dealing with the diagonal members their stresses will be resolved into three components parallel to the axes X, Y, and Z, as indicated; the Z-axis being perpendicular to the plane of the truss. The Z-component in each diagonal will be equal to the shear in the panel, and will have the following values: in panel $C\,F$ = 8,000 lbs., panel $F\,G$ = 24,000 lbs., and panel $G\,B$ = 40,000 lbs. The stress in any diagonal = Z-component $\times \frac{\text{length}}{16}$. The stresses in the several lateral struts are equal to the respective shears.

The effect of the lateral stresses upon the main truss remains to be determined. At each joint resolve the stress in the diagonal into X, Y and Z components. The Z-component is balanced by the stress in the strut; the X and Y components act in the plane of the main truss as loads upon that truss. At joint C' the diagonals $C'F$ and $C'E$ act. The Z-component in each = 8,000 lbs. The X-component $= 8{,}000 \times \frac{20}{16} = 10{,}000$ lbs.; and the Y-component $= 8{,}000 \times \frac{3}{16} = 1{,}500$ lbs. On the leeward truss the X-components act toward the abutments from the centre and the Y-components act downward. At F and E the same forces act, but in an opposite direction. Then in panel FG the X-component of $F'G = 24{,}000 \times \frac{20}{16} = 30{,}000$ lbs.; and the Y-component $= 24{,}000 \times \frac{9}{16} = 13{,}500$ lbs. In $G'B$ the corresponding values are 50,000 lbs. and 37,500 lbs., respectively. Combining the vertical or Y-components with the vertical loads from the transverse bracing, we have the

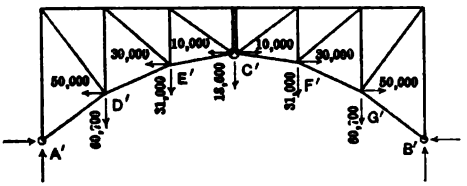

FIG. 33.

following downward loads acting on the truss $A'B'$. At C', $1{,}500 \times 2 + 15{,}600 = 18{,}600$ lbs.; at F', $13{,}500 + 17{,}500 = 31{,}000$ lbs.; and at G', $37{,}500 + 23{,}200 = 60{,}700$ lbs. The upward loads on truss $A\,C\,B$ will be the same numerically, but applied on joints nearer the abutment in each case. The X-components of the diagonal stresses act as horizontal forces at the joints. The total vertical and horizontal forces acting on the truss $A'C'B'$ are shown in Fig. 33. The stresses resulting therefrom are readily determined in the usual manner.

SECTION III.—ARCHES OF TWO HINGES

119. General Formulas for Reactions for an Arch Rib of Two Hinges.—Some of the general notation employed will be here given.

ρ = radius of curvature;

α = inclination of arch axis at any point;

α_1 = inclination of arch axis at springing line;

L = length of arch axis;

M = bending moment at any section due to given loads and the true reactions;

M' = bending moment at any section due to given loads and vertical reactions only.

The reactions V_1 and V_2, Fig. 34, are obtained at once from moments at B and A. They are

$$V_1 = \Sigma P (1 - k) \quad . \quad . \quad . \quad . \quad . \quad . \quad . \quad (1)$$

and

$$V_2 = \Sigma P k \quad . \quad . \quad . \quad . \quad . \quad . \quad . \quad . \quad (2)$$

These are the same as in a simple beam or truss.

The value of H is obtained from the condition explained in Art. 105,

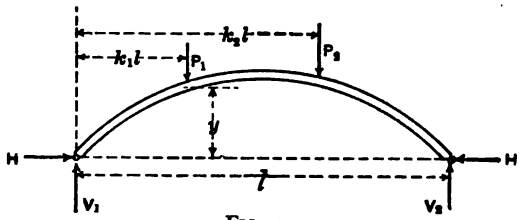

FIG. 34.

that the horizontal deflection of B referred to A and the tangent at A is zero. From eq. (19), Art. 103, noting that $\int_A^B d x = l$, we have, therefore, the condition that

$$\int_A^B \frac{M y d s}{E I} - \int_A^B \frac{f d x}{E} + \int_A^B \frac{f y d s}{E \rho} + \omega t l = 0, \quad . \quad . \quad (3)$$

in which M = bending moment and f = average compressive stress at any section, ω = coefficient of expansion, t = change of temperature, and ρ = radius of curvature. The first term takes account of the effect of bending moment and the second and third terms the effect of direct compression.

To bring eq. (3) into a form to solve for the unknown reaction H, it is necessary to express the quantities M and f in terms of H and known quantities. The bending moment M may be separated into two parts: a moment M' due to vertical forces only (loads and vertical

reactions), and a moment M'' due to the forces H. The moment M' is the same as in a simply supported structure and is readily calculated. The moment $M'' = H\,y$, hence

$$M = M' - H\,y. \quad . \quad . \quad (4)$$

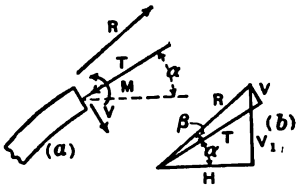

FIG. 35.

To determine f, consider the forces acting at any section, Fig. 35. Fig. (*b*) shows the relation between the resultant R, the thrust T, and the horizontal component H, of the reaction. The angle β is generally small, as the direction of the resultant follows approximately the line of the arch. Hence we have, approximately, $T = H \sec \alpha$, and therefore,

$$f = \frac{T}{A} = \frac{H \sec \alpha}{A} \quad . \quad . \quad . \quad . \quad . \quad . \quad . \quad (5)$$

and

$$\int_A^B \frac{f y\,ds}{E\rho} - \int_A^B \frac{f\,dx}{E} = \frac{H}{E}\int_A^B \frac{\sec \alpha}{A}\left(\frac{y\,ds}{\rho} - dx\right) \quad . \quad (6)$$

Again, if the curvature is uniform or approximately so, we have, from Fig. 36, $y = \rho \cos \alpha - \rho \cos \alpha_1$, and $dx = ds \cos \alpha$, hence $\frac{y\,ds}{\rho} - dx = (\cos \alpha - \cos \alpha_1)\,ds - dx = -ds \cos \alpha_1$, in which α_1 is the inclination at the springing line. The second member of eq. (6) therefore becomes

$$-\frac{H}{E}\cos \alpha_1 \int_A^B \frac{ds}{A \cos \alpha}.$$

For any given arch the quantity $A \cos \alpha$ can be calculated for various sections along the arch and an average value determined. Generally the cross-section A will vary approximately with $\sec \alpha$ and for the purposes of the present calculations it is sufficiently accurate to assume this to be the case. If then A_0 represents the value of the cross-section at the crown, or the average value of $A \cos \alpha$, we have $\int_A^B \frac{ds}{A \cos \alpha} = \frac{L}{A_0}$, in which L = length of the arch axis. We have then, finally, the approximate expression for the deformation due to thrust, eq. (6),

$$\int_A^B \frac{f y\,ds}{E\rho} - \int_A^B \frac{f\,dx}{E} = -\frac{H \cos \alpha_1 L}{E A_0}. \quad . \quad . \quad . \quad (7)$$

As this term representing the effect of thrust is relatively small in any case, the errors involved in the approximations used are generally of no practical consequence.

Substituting from (4) and (7) in eq. (3), we have, in terms of H and known quantities,

$$\int_A^B \frac{M' y\, ds}{EI} - H\int_A^B \frac{y^2\, ds}{EI} - \frac{H L \cos \alpha_1}{E A_o} + \omega t l = 0. \quad . \quad (8)$$

Solving for H we get, finally, the general expression,

$$H = \frac{\int_A^B \frac{M' y\, ds}{I} + E \omega t l}{\int_A^B \frac{y^2\, ds}{I} + \frac{L \cos \alpha_1}{A_o}}. \quad . \quad . \quad . \quad . \quad . \quad (9)$$

Eq. (9) is the complete expression for H, and includes the effect of the deformation due to axial thrust and also that due to temperature.

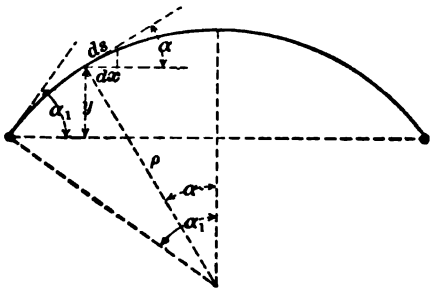

FIG. 36.

Generally the effect of temperature is separately considered, in which case the term $E \omega t l$ in (9) disappears. The effect of temperature alone is given by the equation

$$H_t = \frac{E \omega t l}{\int_A^B \frac{y^2\, ds}{I} + \frac{L \cos \alpha_1}{A_o}}. \quad . \quad . \quad . \quad . \quad . \quad (10)$$

120. ***Arch on Yielding Supports.***—In case the supports move horizontally a certain distance Δx, due either to settlement or to the use of a tie rod instead of fixed abutments, this term Δx must be

added to the second number of eq. (3). The general expression for H in eq. (9) becomes then (neglecting temperature changes)

$$H = \frac{\int_A^B \frac{M' y\, ds}{I} - E\Delta x}{\int_A^B \frac{y^2\, ds}{I} + \frac{L \cos \alpha_1}{A_o}}. \quad . \quad . \quad . \quad . \quad (11)$$

If the tie rod has a cross-section of A_1 and length l, then $\Delta x = \frac{H l}{A_1 E}$ and we have from (11)

$$H = \frac{\int_A^B \frac{M' y\, ds}{I}}{\int_A^B \frac{y^2\, ds}{I} + \frac{L \cos \alpha_1}{A_o} + \frac{l}{A_1}}. \quad . \quad . \quad . \quad . \quad (12)$$

Where a tie rod is used the temperature effect is measured by the difference in temperature between the tie rod and the other truss members.

121. *Relative Effect of Deformation Due to Thrust.*—For arches of considerable rise the effect of distortion due to thrust is small and may be neglected. For $\alpha_1 = 90°$ it becomes zero, and the value of H is then

$$H = \frac{\int_A^B \frac{M' y\, ds}{I}}{\int_A^B \frac{y^2\, ds}{I}}. \quad . \quad . \quad . \quad . \quad . \quad (13)$$

The relative effect of thrust may be estimated by comparing the two terms in the denominator of eq. (9). Placing approximately $I \cos \alpha =$ constant, $= I_o$, we may write $\frac{ds}{I} = \frac{ds \cos \alpha}{I_o} = \frac{dx}{I_o} = \frac{dx}{A_o r^2}$, hence the denominator becomes $\frac{1}{A_o}\left[\int_A^B \frac{y^2\, dx}{r^2} + L \cos \alpha_1\right]$. For a parabolic arch with a rise of one-fifth the span length and a depth of rib of one-fifth the rise, the value of the second term is about 1.5 per cent of the first term and hence the error arising from neglecting this term is about 1.5 per cent. For a greater rise or a less depth of rib the error becomes less in proportion to the square of these quantities. Excepting for flat arches the second term may therefore be neglected.

However, as the term $\frac{L \cos \alpha_1}{A_0}$ is constant and need be calculated but once, it is very little additional work to include it.

Note that eq. (13) may be written out at once from the general equation for deflection of beams of Art. 214, Part I. The deflection due to vertical loads $= \int_A^B \frac{M' dx}{EI} . m$ and that due to the force $H = H \int_A^B \frac{y dx}{EI} m$. Placing these equal and solving for H, we have

$$H = \frac{\int_A^B \frac{M' dx}{I} . m}{\int_A^B \frac{y dx}{I} . m}, \quad \ldots \ldots \quad (14)$$

in which m is the moment due to one-pound loads acting horizontally at B and A, which in this case is equal to y.

122. General Method of Application.—To apply any of the foregoing equations for H it is necessary, first, to assume an arch. Then if it is of such form and section as to permit of integration the solution is directly effected. If the form does not admit of integration the arch must be divided into short lengths and the several values under the integrals determined for the various sections by the process of summation.

123. The Parabolic Arch with Variable Moment of Inertia.—A form of arch which admits of the ready solution of H is one in which

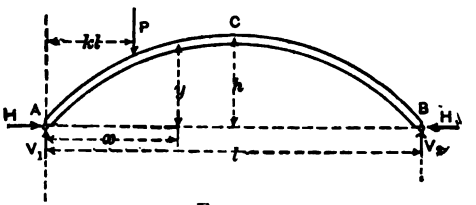

FIG. 37.

the axis is a parabola and the moment of inertia increases in proportion to the inclination of the axis from the horizontal. Even though such form and variation be not strictly followed in the design, the resulting formulas may be applied with little error to flat arches, and may be used for approximate or preliminary values in forms varying more widely from that assumed.

Let $A\,B$, Fig. 37, be a parabolic arch in which I varies with sec α. Let I_o = moment of inertia at the crown; then in general $I = I_o \sec \alpha$. With origin at A the equation of the parabolic axis is $\frac{h-y}{h} = \frac{(\frac{1}{2}\,l-x)^2}{(\frac{1}{2}\,l)^2}$,

or
$$y = 4\,h\left(\frac{x}{l} - \frac{x^2}{l^2}\right). \quad . \quad . \quad . \quad . \quad . \quad . \quad (15)$$

Also, for any point, $d\,s = d\,x \sec \alpha$. Hence $\frac{d\,s}{I} = \frac{\sec \alpha\, d\,x}{I_o \sec \alpha} = \frac{d\,x}{I_o}$. Eq. (9) of Art. 119 then becomes

$$H = \frac{\int_A^B M'\,y\,d\,x + E\,I'\,\omega\,t\,l}{\int_A^B y^2\,d\,x + \frac{L\,I_o \cos \alpha_1}{A_o}}. \quad . \quad . \quad . \quad . \quad . \quad (16)$$

124. *Value of H for a Single Load P, Temperature Constant.*— Assuming the arch loaded with a single vertical load P, Fig. 37, the value of M' is given by the following expressions:

$$\left.\begin{array}{l} \text{for } x < k\,l,\ M' = V_1\,x = P\,(1-l.)\,x \\ \text{for } x > k\,l,\ M' = V_2\,(l-x) = P\,k\,(l-x) \end{array}\right\} \quad . \quad . \quad . \quad (17)$$

Substituting these values of M', and the value of y from (15), we have

$$\int_A^B M'\,y\,d\,x = 4\,P\,h \int_o^{k\,l} (1-k)\,x\left(\frac{x}{l} - \frac{x^2}{l^2}\right) d\,x +$$

$$4\,P\,h \int_{k\,l}^{l} k\,(l-x)\left(\frac{x}{l} - \frac{x^2}{l^2}\right) d\,x, \text{ and } \int_A^B y^2\,d\,x = 16\,h^2 \int_o^l \left(\frac{x}{l} - \frac{x^2}{l^2}\right)^2 d\,x.$$

Performing these integrations and reducing we have:

For a single load P,

$$H = \frac{\frac{5}{8}\,P\,\frac{l}{h}\,(k - 2\,k^3 + k^4)}{1 + \frac{15}{8}\,\frac{L\,I_o \cos \alpha_1}{l\,h^2\,A_o}}. \quad . \quad . \quad . \quad . \quad . \quad (18)$$

Except for very flat arches, the second term in the denominator of (18) may be neglected, giving

$$H = \frac{5}{8}\,P\,\frac{l}{h}\,(k - 2\,k^3 + k^4). \quad . \quad . \quad . \quad . \quad . \quad (19)$$

If a tie rod is used of cross-section A_1, the value of H is found from eq. (12) to be

$$H = \frac{\frac{5}{8} P \frac{l}{h} (k - 2k^3 + k^4)}{1 + \frac{15}{8} \frac{I_o}{l h^2} \left(\frac{L \cos \alpha_1}{A_o} + \frac{l}{A_1} \right)}. \quad . \quad . \quad . \quad (20)$$

125. *Value of H for Temperature Change.*—For a rise of temperature of t degrees we have, by substituting in (10)

$$H_t = \frac{E I_o \omega t l}{\frac{8}{15} h^2 l + \frac{L I_o \cos \alpha_1}{A_o}}. \quad . \quad . \quad . \quad . \quad (21)$$

And for any but flat arches

$$H_t = \frac{15}{8} \frac{E I_o \omega t}{h^2}. \quad . \quad . \quad . \quad . \quad . \quad . \quad (22)$$

126. *Value of H for End Displacement.*—For a horizontal movement of the end of Δx, due to yielding of the support, the value of H is found from (21) by substituting $-\Delta x$ for $\omega t l$, giving

$$H_d = -\frac{E I_o \Delta x}{\frac{8}{15} h^2 l + \frac{L I_o \cos \alpha_1}{A_o}}. \quad . \quad . \quad . \quad . \quad (23)$$

In the case where temperature or displacement stresses alone are to be determined the approximate term $\frac{L I_o \cos \alpha_1}{A_o}$ is more accurately written $\frac{l I_o \cos \alpha_1}{A_o}$, for in this case the thrust at any point due to the single force H is H, cos α, and the value of eq. (7) becomes $-\frac{H \cos \alpha_1 l}{E A_o}$, where A_o is the average cross-section. The error indeed is, however, of no practical consequence.

127. *The Reaction Locus.*—Since the reaction lines (equilibrium polygon) for load P, Fig. 38, pass through A and B, these lines become known by determining the distance y_o of the intersection i above the axis. Referring to the force polygon, Fig. 38 (*a*), we have, by similar figures, $\frac{y_o}{k l} = \frac{V_1}{H}$. Or since $V_1 = P (1 - k)$, we have, in general, for any form of arch,

$$y_o = k l (1 - k) \frac{P}{H}. \quad . \quad . \quad . \quad . \quad . \quad (24)$$

For the parabolic arch, neglecting the effect of rib shortening, we have from (19)

$$y_0 = \frac{1.6\,h}{1 + k - k^2}. \quad . \quad . \quad . \quad . \quad . \quad . \quad . \quad (25)$$

The locus of y_0, shown in Fig. 38 by the line $m\,n$, is called the "reaction locus." In graphical analysis it is convenient to first construct this locus from the expression for y_0. Having this curve the

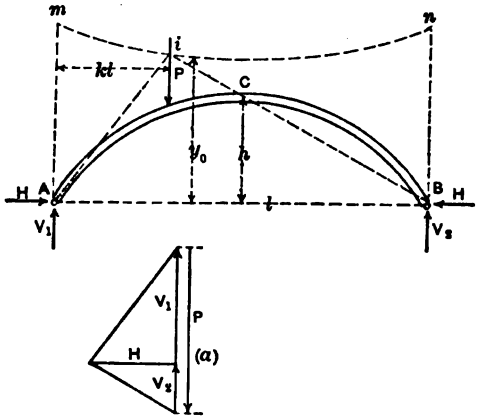

FIG. 38.

reaction lines for a load at any point can be drawn at once, and used in the same manner as explained in Art. 108 for the three-hinged arch. The use of this locus is also further expained in Art. 140.

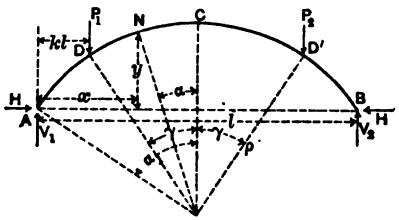

FIG. 39.

128. The Circular Arch of Constant Section.—*Value of H for a Single Load.—Temperature Constant.*—Let $A\,C\,B$, Fig. 39, represent a circular arch of constant section. Let ρ = radius of curvature,

α_1 = inclination of arch at the hinge, γ = inclination at the load point, and α = inclination at any section N. In deriving the value of H for a single load it will simplify the integrations to first determine H for two equal loads, P_1 and P_2, symmetrically placed. The value of H for a single load is then one-half of the value for the two loads.

Referring to the general expression for H, eq. (9), the values of M' and y will first be expressed in polar coordinates. For any section N,

$$x = \rho (\sin \alpha_1 - \sin \alpha); \; k\,l = \rho (\sin \alpha_1 - \sin \gamma);$$

$$y = \rho (\cos \alpha - \cos \alpha_1); \; d\,s = \rho\, d\,\alpha.$$

For two equal loads, P, we have $V_1 = V_2 = P$. Then the values of M' are

$$\text{for } \alpha < \gamma, \; M' = V_1\, k\,l = P\,\rho (\sin \alpha_1 - \sin \gamma);$$

$$\text{for } \alpha > \gamma, \; M' = V_1\, x = P\,\rho (\sin \alpha_1 - \sin \alpha).$$

Eq. (9) then becomes ($\omega = 0$).

$$H = \frac{P\left[2\rho^2 \int_0^{\gamma} (\sin \alpha_1 - \sin \gamma)(\cos \alpha - \cos \alpha_1)\, d\alpha + 2\rho^2 \int_{\gamma}^{\alpha_1} (\sin \alpha_1 - \sin \alpha)(\cos \alpha - \cos \alpha_1)\, d\alpha\right]}{2\rho^2 \int_0^{\alpha_1} (\cos \alpha - \cos \alpha_1)^2\, d\alpha + \frac{L\,I \cos \alpha_1}{A}}. \quad (26)$$

Performing the integrations, substituting $2\,\rho\,\alpha_1$ for L, and dividing by two, we have, for a single load P

$$H = \frac{P\rho^2 \left[\sin^2 \alpha_1 - \sin^2 \gamma - 2 \cos \alpha_1 (\alpha_1 \sin \alpha_1 - \gamma \sin \gamma - \cos \gamma + \cos \alpha_1)\right]}{2\rho^2 (\alpha_1 - 3 \cos \alpha_1 \sin \alpha_1 + 2\,\alpha_1 \cos^2 \alpha_1) + \frac{2\,\alpha_1 I \cos \alpha_1}{A}}. \quad (27)$$

For a semicircular arch, $\alpha_1 = 90°$, and the value of H becomes

$$H = \frac{P \cos^2 \gamma}{\pi}. \quad . \quad . \quad . \quad . \quad . \quad . \quad . \quad (28)$$

129. *Value of H for Temperature Change.*—For a rise of temperature of t degrees the value of H will be obtained from (9), omitting the term containing M'. There results

$$H_t = \frac{E\,I\,\omega\,t\,l}{2\rho^2 (\alpha_1 - 3 \cos \alpha_1 \sin \alpha + 2\,\alpha_1 \cos^2 \alpha_1) + \frac{L\,I \cos \alpha_1}{A}}. \quad . \quad . \quad . \quad . \quad (29)$$

For a semicircular arch, $l = 2\rho$ and

$$H_t = \frac{8 E I \omega t}{\pi l^2}. \quad . \quad . \quad . \quad . \quad . \quad . \quad . \quad (30)$$

130. *Value of H for End Displacement.*—For an end movement of Δx the value of H is given by substituting $-\Delta x$ for $\omega t l$ in eq. (29) or (30).

131. *The Reaction Locus.*—The value of y_o is given by the general expression of eq. (24). Here we have $k l = \rho (\sin \alpha_1 - \sin \gamma)$; $l = 2\rho \sin \alpha_1$; and $1 - k = \dfrac{\sin \alpha_1 + \sin \gamma}{2 \sin \alpha_1}$.

Substituting in (24) we have

$$y_o = \frac{P}{H} \cdot \frac{\rho (\sin^2 \alpha_1 - \sin^2 \gamma)}{2 \sin \alpha_1}. \quad . \quad . \quad . \quad . \quad (31)$$

For a semicircular arch

$$y_o = \frac{\pi \rho}{2}, \quad . \quad . \quad . \quad . \quad . \quad . \quad . \quad . \quad (32)$$

that is, the reaction locus for a semicircular arch is a straight line drawn a distance 1.57ρ above the springing line.

132. Calculation of H for Arch Ribs, for a Single Load P.—Let $A B$, Fig. 40, be a two-hinged arch rib of any form. Neglecting temperature effect the general expression for H is

$$H = \frac{\Sigma \dfrac{M' y \, d s}{I}}{\Sigma \dfrac{y^2 \, d s}{I} + \dfrac{L \cos \alpha_1}{A_o}},$$

in which M' is the bending moment at any point due to vertical forces only (the same as in a straight beam).

Divide the arch into convenient subdivisions of equal or unequal length. Generally it will be convenient to assume either $d s$ as constant or to make $d s / I$ constant. The constant term $L \cos \alpha_1 / A_o$ is readily calculated. Call this term B. Calculate now the value of $y \, d s / I$ for each subdivision and let Q represent in general this value. Then

$$H = \frac{\Sigma M' Q}{\Sigma y Q + B}. \quad . \quad . \quad . \quad . \quad . \quad . \quad . \quad (33)$$

The quantity M' for a single load is given by the equations

$$\left.\begin{aligned} &\text{for } x < k\,l,\ M' = P\,(1-k)\,x \\ &\text{for } x > k\,l,\ M' = P\,k\,(l-x) \end{aligned}\right\} \quad . \quad . \quad . \quad . \quad (34)$$

Hence we may write

$$\Sigma\, M'\, Q = P\, \Sigma_o^{kl}\, (1-k)\, x\, Q + P\, \Sigma_{kl}^{l}\, k\,(l-x)\, Q. \quad . \quad (35)$$

Now suppose a load equal to Q be applied to a beam $A\,B$ at a distance x from A, Fig. 40 (b). The bending moment at D due to this load will be equal to $Q\,x\,(1-k)$ for $x < k\,l$, and $Q\,(l-x)\,k$ for $x > k\,l$. If a series of loads equal to the several values of Q be applied to the beam

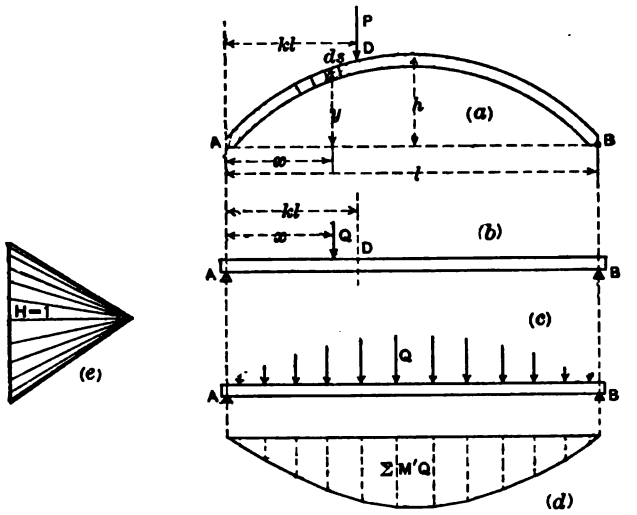

FIG. 40.

at the corresponding distances x, the total moment at D due to all these loads will be equal to $\Sigma_o^{kl}\, Q\, x\, (1-k) + \Sigma_{kl}^{l}\, Q\,(l-x)\,k$. This quantity is identical with the value of $\Sigma\, M'\, Q$ of eq. (35) for $P = 1$. The value of $\Sigma\, M'\, Q$ for a unit load at other points will likewise be equal to the bending moment in a straight beam at the corresponding point, due to the same loads Q as used before. Hence to determine all the values of $\Sigma\, M'\, Q$, or $\Sigma\, M' \frac{\gamma\, d\, s}{I}$, for all sections of the arch, calculate the bending moments in a straight beam at corresponding

points, due to the loads Q. Graphically, all of these values will be given by a single equilibrium polygon, using the several values of Q for loads. Such construction is shown in Fig. (*c*), (*d*), and (*e*). Taking a pole distance of unity, the ordinates to the equilibrium polygon give at once the desired values.

The quantity $\Sigma\, y\, Q$ of eq. (33) may be calculated graphically in a somewhat similar manner, but as this term is constant no great advantage is gained. For graphical construction lay off the values of Q as horizontal loads acting on a vertical cantilever beam of length h, at the proper distances y from the fixed end. Then an equilibrium polygon gives $\Sigma\, y\, Q$.

The values of H for unit loads are now obtained by dividing the values of $\Sigma\, M'\, Q$, or the ordinates of equilibrium polygon of Fig. 40 (*d*), by the quantity $\Sigma\, y\, Q + B$, thus giving the influence line for H. The equilibrium polygon of Fig. (*d*) is itself such an influence line, using as the scale unit the quantity $\Sigma\, y\, Q + B$. Or, this quantity may be used for the pole distance in Fig. 40 (*e*), in which case the polygon becomes the influence line for H. For an example of the use of this method see Art. 146.

133. **The Braced Arch.**—*General Formula for* H.—For the braced or trussed arch with parallel chords and small depth, the methods and formulas for solid beams can be applied with little error. In such forms the influence of the web members is relatively so small that the deformations are practically the same as for a solid beam of the same moment of inertia (determined from chord sections only). Hence the reactions will be the same as for the beam and may be determined in the same way. The reactions being known the chord and web stresses are found from moments and shears as explained in Art. 96.

For braced arches of variable depth the results obtained from beam formulas are not sufficiently accurate, and for such forms the general method of deflections must be applied to the actual form selected. The application of this method requires a preliminary design to be made in some manner, as the deflections are dependent upon the cross-sections of the members. This preliminary design may be made by the use of an approximate formula for H, such as for the parabolic arch rib, or it may be assumed for the first analysis that the cross-sections of all members are the same, or they may be varied in proportion in

accordance with some similar design previously worked out. It is to be noted that the actual cross-sections are not needed, but only the relative sections of the various members.

The preliminary design being made in whatever manner, the true value of H for any loading is given by the general formula for redundant

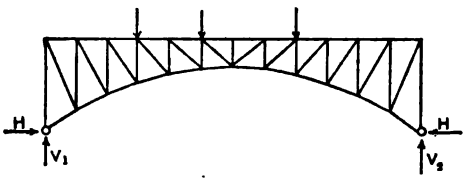

FIG. 41.

members of Art. 222 of Part I. Here the reaction H will be taken as redundant. The general value of H is (E being assumed constant):

$$H = \frac{\Sigma \frac{S' u l}{A}}{\Sigma \frac{u^2 l}{A}}, \quad \ldots \ldots \ldots \quad (36)$$

in which S' = stress in any member due to the vertical forces (loads and vertical reactions) only;

u = stress in any member due to a force of one pound applied horizontally at the hinges and acting *outward;* and

l and A = length and cross-section of any member.

The numerator of (36) is the outward deflection of one end, with arch supported on rollers and acted upon by the vertical forces, and the denominator is the outward deflection of the same point caused by a one-pound load.

In this case the formula takes full account of all effects of deformation in each member, whether due to moment or thrust, so-called, and hence is not subject to the correction for thrust as in the case of a beam formula.

134. *Use of a Tie Rod.*—If a tie rod be employed to restrain the ends then the problem is exactly the same as that of a single redundant member. The formula is the same as (36), but the summation in the denominator must now include the tie rod for which $u = 1$.

135. *Value of H for a Single Load.*—For the analysis of live-load stresses it is desirable, as in other similar problems, to determine the reactions for a single load at each load point. If the algebraic method is used it requires the application of eq. (36) several times, which is a somewhat tedious operation. The stresses u may conveniently be determined by a single stress diagram for a unit horizontal force at each end. The stresses S' are different for each different position of load, but, noting that for members to the left of the load the stresses are

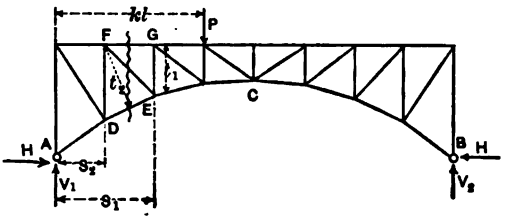

FIG. 42.

proportional to V_1 and for those on the right they are proportional to V_2, the calculations become relatively simple.

Thus in Fig. 42 the stress in $F\,G$ for load P at G, or at any point on the right of the section, $= V_1\, s_1/t_1 = P\,(1 - k)\,\frac{s_1}{t_1}$; and likewise, stress in $D\,E = P\,(1 - k)\,\frac{s_2}{t_2}$; and, in general, the stress in any member $= V_1 s/t$, where s = lever arm of the reaction V_1, and t = lever arm of the member. Hence, for all positions of P on the right of the section cutting the given member, the stress is found by multiplying the quantity $P\,s/t$ by the proper value of $(1 - k)$. When the load is on the left of the section the stress is found from the right reaction, and is equal to $P\,k\,\frac{s_1}{t}$, where s_1 is the arm of the right reaction.

A further simplification may be made in the calculations by the use of symmetrical loads. Assume the truss loaded with two unit loads P, placed symmetrically (Fig. 43). The value of H determined for these two loads will be twice that due to a single load. The stresses due to the symmetrical loads are very readily calculated. The vertical reactions are each equal to P. Then for members to the left of P_1,

the stress is the same for all positions of the loads, and is equal to $P_1 s/t$, in which s is the lever arm of the reaction and t is the lever arm of the member. For all members between the loads, the moment of the external forces is constant and equal to $P k l$. Hence all these stresses are equal to $P k l/t$. A single graphical diagram will give all

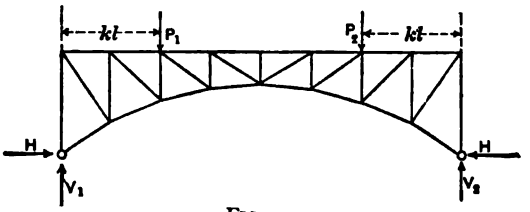

FIG. 43.

the stresses $P s/t$. The stresses $P k l/t$ are obtained by calculating the values of l/t and then multiplying by the various values of k for the different positions of the loads. This method is illustrated in the example of Art. 146.

136. *Graphical Method of Calculating H for a Single Load.*—In calculating H for trussed arches, use may be made of the displacement diagram according to the method employed in Art. 223, of Part I, as follows: Construct a displacement diagram for the arch (Fig. 44),

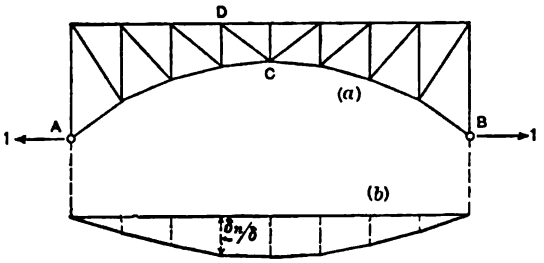

FIG. 44.

loaded with unit loads at A and B and acting outward, no other loads on the structure. The centre vertical may be assumed as standing fast. The stresses for use in this process can be most readily obtained from a stress diagram. Then from this displacement diagram measure the vertical deflections of the several load points relative to

the fixed ends A and B, and also the horizontal deflection of B. Let δ_n represent the vertical displacement of any point, and δ the horizontal movement of B with respect to A (twice the displacement for one-half the arch). Then if the values δ_n/δ be plotted as in Fig. (*b*), the resulting curve becomes the influence line for H. For if δ_n = vertical movement of any load point D, due to one pound at B, then, conversely, the horizontal movement of B caused by a unit load at D will also be δ_n. The deflection due to one pound at $B = \delta$, hence the reaction developed by one pound at D will be δ_n/δ. The value δ_n is, in fact, the value of $\Sigma \frac{S' u l}{A}$ of eq. (36) and $\delta = \Sigma \frac{u^2 l}{A}$ (E being omitted throughout). A single displacement diagram will thus give the necessary data for the determination of H for all load points. See Art. 146, for example.

137. *The Reaction Locus* for the braced arch is determined in the same way as explained in Art. 127 for the arch rib, and the value of y_o is given by the general formula of eq. (24). The locus is used in the manner described in Art. 140.

138. *Value of H for Temperature Change.*—A rise of temperature of t degrees causes an increase of span length, if unrestrained, of $\omega t l$. The thrust necessary to resist this is found by replacing the numerator of eq. (36) by $\omega t l$ (retaining the value E), giving

$$H_t = \frac{\omega t l}{\Sigma \frac{u^2 l}{E A}}. \quad . \quad . \quad . \quad . \quad . \quad . \quad . \quad (37)$$

If a tie rod is employed, subjected to the same temperature variation as the arch, there will be no change in H. If the tie rod is subjected to an increase of temperature t', different from t, then

$$H = \frac{\omega (t - t') l}{\Sigma \frac{u^2 l}{E A}}. \quad . \quad . \quad . \quad . \quad . \quad . \quad . \quad (38)$$

139. Stress Calculation.—*A. Dead-Load Stresses.*—The reactions having been determined, the dead-load stresses are determined in the same manner as explained for the three-hinged arch. For the parabolic or circular arch, for which convenient formulas exist for H for a single load, the total value of H for dead load is conveniently found by sum-

mation for the several joint loads. For the more general case of Arts. 119–122, and for the braced arch, the summations may be made at once for the entire dead load; but as the calculation of live-load stresses requires the determination of H for a single load at each joint, the value of H for dead load is in this case also conveniently found by summation of results for separate joint loads.

140. *B. Live-Load Stresses.—Use of the Reaction Locus.*—In finding the position of loads for maximum stress the reaction lines may be used as in Art. 108, for the three-hinged arch. The reaction locus is first constructed, after which the method is the same for all forms of arches.

Let Fig. 45 represent any two-hinged arch and $m\ n$ the reaction locus. Then for maximum stress in member $C\ D$, with centre of

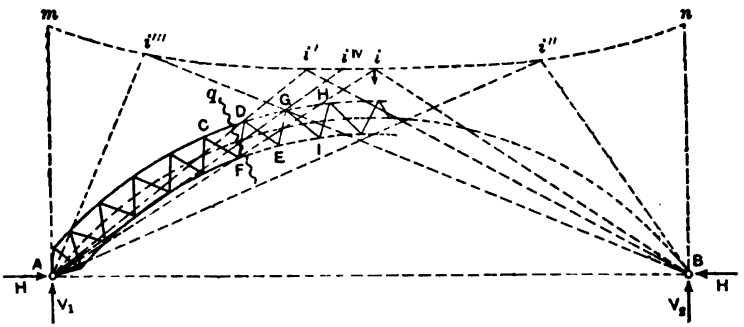

FIG. 45.

moments at F, a load at i produces no stress, while all loads to the right produce tension and all loads to the left compression. For $F\ E$, all loads to the right of i' cause compression and all loads to the left tension. For the web member $D\ F$, draw $A\ i''$ toward the intersection of $C\ D$ and $F\ E$. Then loads between D and i'' cause compression in $D\ F$, while loads to the right of i'' and to the left of F cause tension in $D\ F$. For such a piece as $E\ I$, with centre of moments at G, loads between i''' and i^{IV} produce positive moment, or tension in $E\ I$, while loads on the remaining portions produce compression.

141. *Use of Influence Lines.—Influence Lines for Moments.*—The value of the bending moment at any point F, Fig. 46, is

$$M = M' - H\,y_1 \quad . \quad . \quad . \quad . \quad . \quad . \quad (39)$$

in which M' is the moment due to the vertical forces only. As in Art. 111, the influence line for M may be constructed by combining that for M' with the curve for $H\,y_1$. Instead, however, of drawing the curve for $H\,y_1$, thus requiring a different curve for each centre of moments,

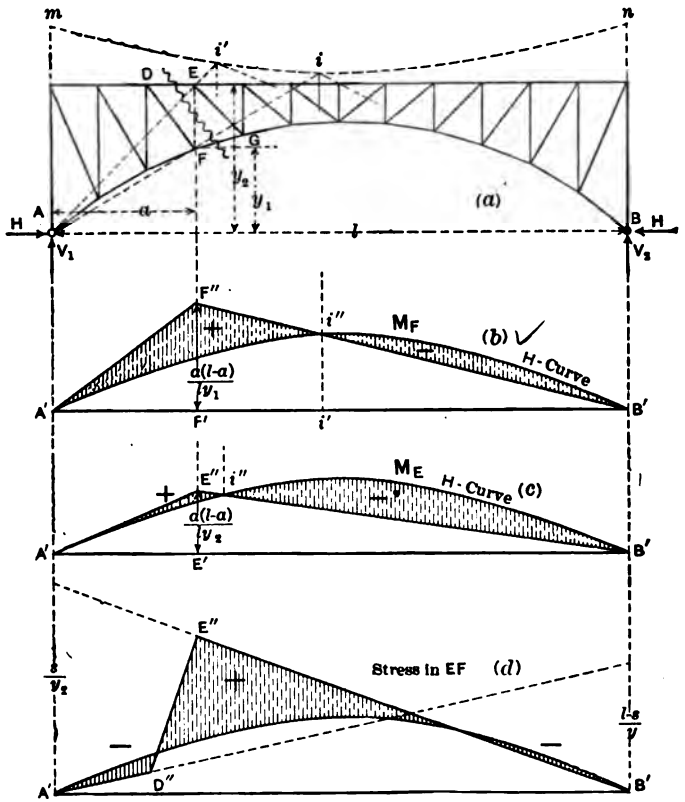

FIG. 46.

the curve for H may be used and the influence line drawn for M'/y_1. Such a diagram for point F is shown in Fig. 46 (*b*). The ordinate $F'F'' = M'/y_1 = \dfrac{a\,(l-a)}{l\,y_1}$. The shaded area will then serve as the influence diagram for M_F, but each ordinate will need to be multiplied by y_1 to give the true value of M, for $M = \left(\dfrac{M'}{y_1} - H\right) y_1$.

As in Art. 111 the influence ordinates become zero at point i'', corresponding to point i on the reaction locus. This locus is, however, not needed in the construction of influence lines.

Fig. (*c*) shows the influence line for moment at E.

142. *Influence Lines for Web Stress or Shear.*—For stress in any web member, as EF, the intersection of DE and FG is found, as usual. This will be in the line of the top chord, distant y_2 from H. If s is the lever arm of V_1 about such intersection and t is the arm of member EF, then for loads on the right the stress in $EF = \left(V_1 s - H y_2\right) \div t = \left(V_1 \frac{s}{y_2} - H\right) \frac{y_2}{t}$, and for loads on the left, stress in $EF = \left(V_1 \frac{l-s}{y_2} - H\right) \frac{y_2}{t}$. The influence line for the quantity in parenthesis is drawn in Fig. 46 (*d*). For actual stress the shaded ordinates are to be multiplied by $\frac{y_2}{t}$.

In the case of a beam, or truss with parallel chords, the influence lines for shear will be needed. These are drawn in a manner similar to that explained in Art. 113 for the three-hinged arch, using the influence line for H as a basis. The shear at D (Fig. 47), for a unit load on the right, $= V_1 \cos\alpha - H \sin\alpha = (1-k)\cos\alpha - H\sin\alpha$; and for loads on the left it is $-V_2\cos\alpha - H\sin\alpha = k\cos\alpha - H\sin\alpha$. These values may be written in the form $[(1-k)\cot\alpha - H]\sin\alpha$, and $(-k\cot\alpha - H)\sin\alpha$. In Fig. 47 (*b*) the line $A'C''B'$ represents H, and the lines $A''B'$ and $A'B''$ represent $(1-k)\cot\alpha$ and $k\cot\alpha$. The shaded area, therefore, is the influence diagram for shear at D. The true values are found by multiplying these values by $\sin\alpha$. For points near the centre $\cot\alpha$ becomes very large and $\sin\alpha$ small, as the effect of H is small. A reduced scale for H may be used for such points. For the centre point the influence of H becomes zero and the influence line is the same as for a straight beam.

143. *Influence Lines for Thrust.*—In analyzing beams it may be convenient to calculate moments with reference to the neutral axis and then to determine the thrust or direct stress separately. For a unit load on the right of point D, Fig. 47, the thrust is $H\cos\alpha + V_1\sin\alpha = H\cos\alpha + (1-k)\sin\alpha$; and for a load on the left, the thrust is $H\cos\alpha - V_2\sin\alpha = H\cos\alpha - k\sin\alpha$. These values

may be written in the form $[H + (1 - k) \tan \alpha] \cos \alpha$ and $(H - k \tan \alpha) \cos \alpha$, respectively. In Fig. 47 (*c*) the curve $A' C'' B'$ is the curve for H. The values $(1 - k) \tan \alpha$ and $k \tan \alpha$ are given by the ordinates to the lines $A'' B'$ and $A' B''$, respectively. The ordinates of the shaded area therefore represent the quantities $H + (1 - k) \tan \alpha$

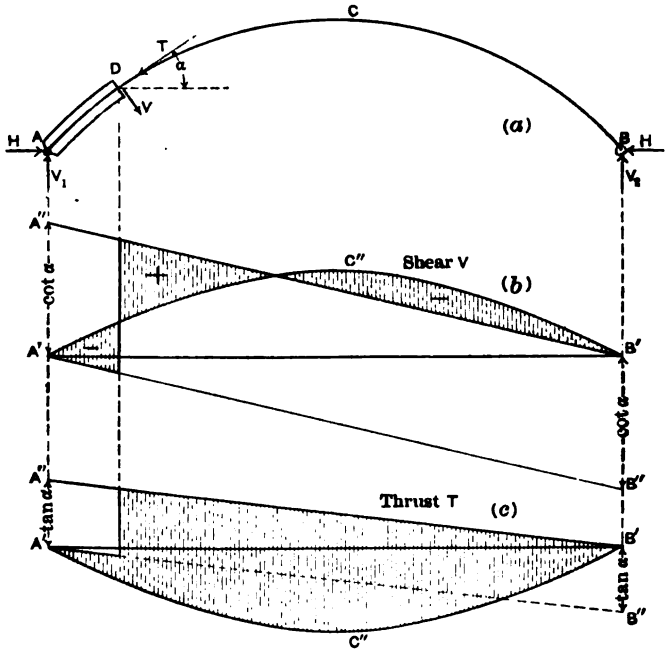

FIG. 47.

and $H - k \tan \alpha$, and hence will serve as the influence diagram for thrust. The true values are found by multiplying all ordinates by $\cos \alpha$.

In general, the maximum thrust at all sections occurs for a fully loaded structure, but the maximum flange or fibre stress occurs for partial load such as will cause large bending moments. The maximum fibre stress can best be found from influence lines for moment, with centre of moment taken at the centre of gravity of the flange or the "kern" point, as explained in Art. 95.

144. *Position of Loads for Maximum Stress.*—The form of the influence lines being curved, no convenient criterion for position of

loads can be stated. For all practical purposes, however, each segment of the influence diagram may be considered a triangle and the position of loads, or the suitable equivalent uniform load, determined on this basis. In getting actual stresses, either for a uniform load or for concentrations, the true influence diagram should be used.

145. Examples.—(1) *Plate Girder Highway Arch.* (Fig. 48.)—An analysis will be made of an arch rib in the form of a plate girder. Assume the following data: Span length = 180 ft.; rise = 36 ft.; depth of girder between flange centres = 4 ft. The arch axis will be taken parabolic in form and the load verticals placed 15 ft. apart horizontally. The live load will be taken at 1,500 lbs. per ft. per girder and the dead load at 1,000 lbs. per ft. Stresses will also be calculated for a temperature change of 60 degrees.

146. *Approximate Analysis.*—The first analysis of stresses will be made by the use of the formulas of Arts. 123–125, these being based on the assumption of a parabolic axis and that the moment of inertia varies with sec α. The effect of thrust will be neglected at first. The formula for H is (eq. (19), Art. 124), $H = \frac{5}{8} P \frac{l}{h} (k - 2k^3 + k^4)$, and for y_o, the ordinate to the reaction locus (eq. (25)), $y_o = \frac{1.6\, h}{1 + k - k^2}$. Values of H and of y_o for unit loads, calculated from these formulas, are given in Table A. Fig. 48 (*b*) shows the influence line for H plotted from these results. The reaction locus is also given in Fig. 48 (*a*).

TABLE A.

Values of y_o and H for $P = 1$.

Load Point.	k	y_o	H
b	1/12	53.5	0.256
c	2/12	50.6	0.495
d	3/12	48.5	0.695
e	4/12	47.2	0.848
f	5/12	46.3	0.943
g	6/12	45.7	0.985

The influence line for H having been constructed, the influence lines for moments are drawn on the same diagram, as explained in Art. 141. Such lines (section d) are shown in Fig. (*b*) for upper and lower flange centres, for the quarter-point and the centre (section g). The values of the various ordinates are given in Table B.

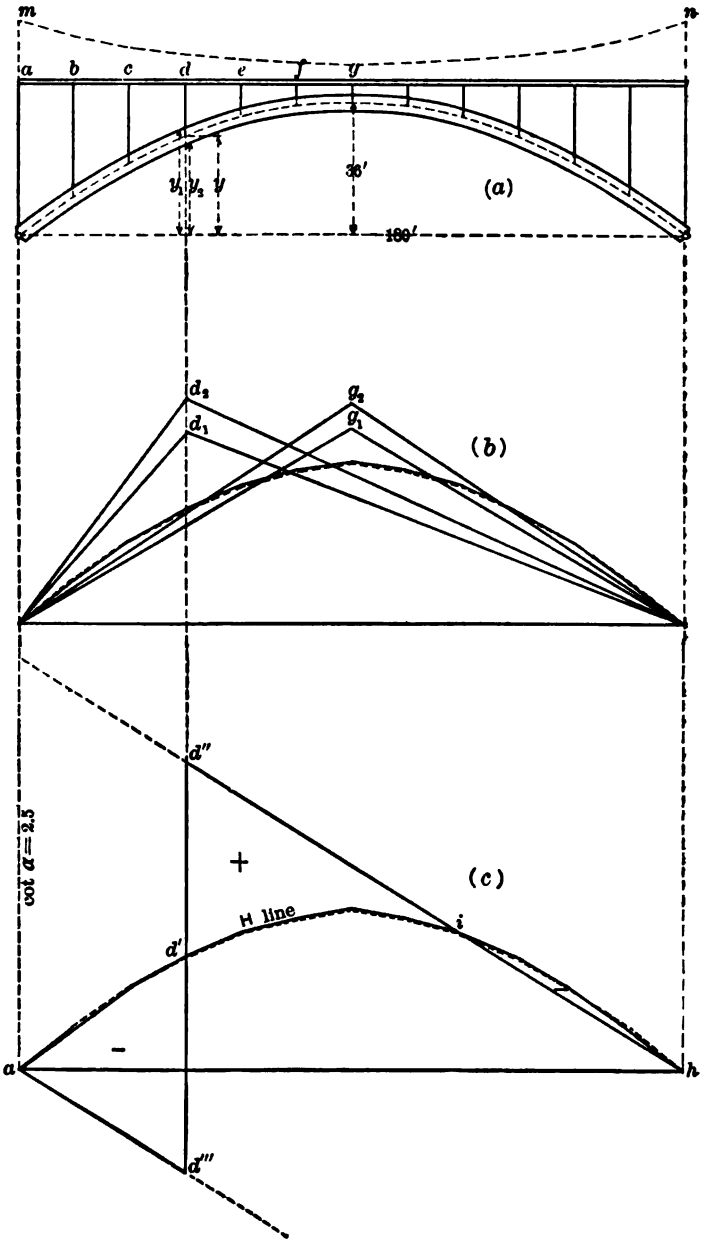

FIG. 48.

TABLE B.

Values of Ordinates y and $\frac{a(l-a)}{l}$.

Load Point.	y	y_1	y_2	$\frac{a(l-a)}{l y_1}$	$\frac{a(l-a)}{l y_2}$
b	11.0	12.72	9.85	1.082	1.396
c	20.0	21.75	18.30	1.150	1.366
d	27.0	28.95	25.25	1.165	1.335
e	32.0	33.95	30.05	1.176	1.330
f	35.0	37.00	33.00	1.182	1.325
g	36.0	38.00	34.10	1.183	1.323

From these influence lines the dead- and live-load moments are obtained. To get the moment in any case, the proper influence area is to be multiplied by the corresponding value of y_1 or y_2 and by the load per foot. Thus for the dead-load moment at section d, top flange, the total area of the influence diagram is -6.29. Multiplying this by y_1 of Table B and by the dead load per foot, gives $M = -6.29 \times 28.95 \times 1{,}000 = -182{,}000$ ft.-lbs. The results for sections at d and g are given in the table below.

Section.	Moment Centre	+ Area.	− Area.	Σ Areas.	D. L. Moment.	Live-Load Moment. +	Live-Load Moment. −
d	Top	15.84	22.33	− 6.29	− 182,000	687,000	967,000
	Bottom	25.92	15.63	+ 10.29	+ 260,000	982,000	395,000
g	Top	3.88	9.04	− 5.16	− 196,000	221,000	515,000
	Bottom	10.54	3.32	+ 7.22	+ 245,000	538,000	169,000

From the values of the maximum moments found in this way a preliminary design was made on the basis of a working stress of 15,000 lbs. per sq. in. on gross area, with resulting flange areas as follows:

Section.	Gross Flange Area.
b,	15 sq. in.
c, d, e,	20 "
f, g	18 "

Any portion of the web to be considered as flange is included in these calculated areas.

147. *Exact Calculation of Stresses.*—Having now an actual design at hand we may proceed to determine the true stresses therein by the methods explained

in Art. 132. The first step is to calculate a new set of values for H. The formula is, neglecting temperature effect,

$$H = \frac{\Sigma \frac{M' y\, ds}{I}}{\Sigma \frac{y^2 ds}{I} + \frac{L \cos \alpha_1}{A_0}}, \quad \ldots \ldots \ldots (a)$$

and for temperature changes

$$H_t = \frac{E \omega t l}{\Sigma \frac{y^2 ds}{I} + \frac{L \cos \alpha_1}{A_0}}. \quad \ldots \ldots \ldots (b)$$

Table C gives the calculations required by eq. (a). The value of ds at each section is taken as one-half the sum of the lengths of the two panels adjacent to the section in question. This leaves a half-length of 9.1 ft. at the end, whose middle ordinate, y, is 3.0 ft. Foot-units are used throughout.

TABLE C.

Calculations for H for Unit Loads.

Section.	y	ds	I	$\frac{y\,ds}{I}$	$\Sigma \frac{M' y\, ds}{I}$	$\frac{y^2 ds}{I}$	H
a	3.0	9.1	.833	22	80	70	0.000
b	11.0	17.9	.833	236	32,800	2,600	0.262
c	20.0	17.0	1.111	306	62,000	6,120	0.495
d	27.0	16.1	1.111	391	86,500	10,580	0.690
e	32.0	15.4	1.111	443	105,400	14,200	0.840
f	35.0	15.3	1.000	535	117,700	18,750	0.937
g	36.0	15.1	1.000	544	121,900	19,600	0.973
		105.9		2,477		71,920	

As explained in Art. 132, the values of $\Sigma \frac{M' y\, ds}{I}$ may be obtained by considering the several quantities $\frac{y\, ds}{I}$ as applied as loads to a simple beam, in the same verticals as the several load points, b, c, d, etc., and calculating the bending moments at these several sections. This calculation may be made graphically or algebraically. The reaction for such a beam will be $2{,}477 - \frac{1}{2}(544) = 2{,}205$ (the section g being at the centre). The moment at sec. b, for example, will then be equal to $2{,}205 \times 15 - 22 \times 11.25 = 32{,}800$; that at c $= 2{,}205 \times 30 - 22 \times 26.25 - 236 \times 15 = 62{,}000$, etc. The several values are given in the table. The quantity $\Sigma \frac{y^2 ds}{I}$ for the entire arch $= 71{,}920 \times$

$2 - 19{,}600 = 124{,}240$. The value of $\frac{L \cos \alpha_1}{A_0}$ of eq. $(a) = \frac{197 \times 0.78}{0.25} = 610$.

The value of H for any load point is then equal to $\frac{\Sigma \frac{M' y\, ds}{I}}{124{,}240 + 610}$. The several values are given in Table C. The small influence of arch shortening, represented by the term 610, is to be noted; also the fact that the small section $d\,s$ at a, in Table C, may be neglected without affecting the value of H. Compare these values with the values in Table A.

From the new values of H a new influence line is drawn, shown by the dotted lines in Fig. 48. The new influence areas may then be determined and the corrected values of bending moments. For the quarter-point and crown the results are as follows:

Section.	Moment Centre.	D. L. Moment.	Live-Load Moment.	
			+	−
d	Top	− 136,300	694,000	898,000
	Bottom	+ 297,000	1,000,000	552,000
g	Top	− 161,800	262,000	505,000
	Bottom	+ 277,000	583,200	167,000

Compare these values with those given on p. 157.

148. *Temperature Stresses.*—Assuming a change of temperature of 60° from the normal, eq. (b) gives $H_t = +\ 2{,}400$ lbs. The moments due to this are equal to $\pm H_t y_1$ and $\pm H_t y_2$. The values for sections d and g are as follows:

Section.	Moment Centre.	Moment Due to Temperature.
d	Top	± 69,500
	Bottom	± 60,700
g	Top	± 91,400
	Bottom	± 81,700

A rise of temperature causes negative moments in the arch.

The value of H_t calculated by the approximate formula of Art. 125 is $H_t = \frac{15\, E\, \omega\, t\, I_0}{8\, h^2} = 2{,}400$, the same as obtained by the more exact method.

149. *Shearing Stresses.*—In arch ribs the shearing stresses, as compared to the bending stresses, are small. The minimum permissible

web thickness will usually be ample, but in designing the riveting of flanges and web it is necessary to determine the maximum shear at a few sections.

Fig. 48 (*c*) shows the influence line for shear at section *d*, plotted as explained in Art. 142. For this section cot $\alpha = 2.5$ and sin $\alpha = 0.37$. Measuring the influence areas we have: area $a\ d'''\ d' = -30.2$; $d'\ d''\ i = +35.7$; $i\ h = -3.3'$; total $= +2.2$. Hence, as in Art. 142, dead-load shear $= 1{,}000 \times 2.2 \times 0.37 = +830$ lbs.; maximum live-load shear $= 35.7 \times 1{,}500 \times 0.37 = +19.800$ lbs.

150. *Values of H for a Circular Arch.*—Calculations have been made for a circular arch of the same rise and same cross-sections as the parabolic arch of Fig. 48, resulting in the following values of H for unit loads:

Section.	Value of H.
b.....	.0.260
c.....	....0.488
d.....	....0.680
e.....	....0.823
f.....	....0.913
g.....	....0.947

The resulting maximum moments are considerably greater at the crown than those of the parabolic arch, but the difference is small between the quarter-point and the end.

151. (2) *Analysis of a Braced Arch.*—Assume an arch of the dimensions shown in Fig. 49 (*a*). The dead load will be taken at 1,200 lbs. per foot per

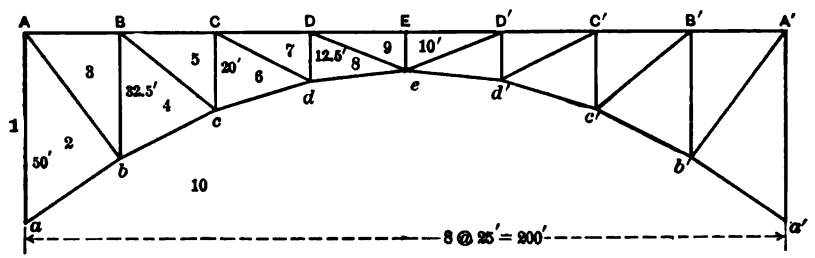

FIG. 49 (*a*).

truss and the live load at 3,000 lbs. The joint loads, therefore, will be 30,000 lbs. and 75,000 lbs., respectively.

a First Approximation.—The first analysis will be made on the assumption that the sectional areas of the members are each equal to unity. On this basis the values of H for a load unity at each joint are determined. The graphical process will be employed.

The first step is to calculate the stresses in the members for a value of $H = 1$. This is conveniently done by means of a stress diagram, given in Fig. (*b*). From this diagram are obtained the stresses u given in the following table. The values of $u\,l$ are then calculated and used in the construction of

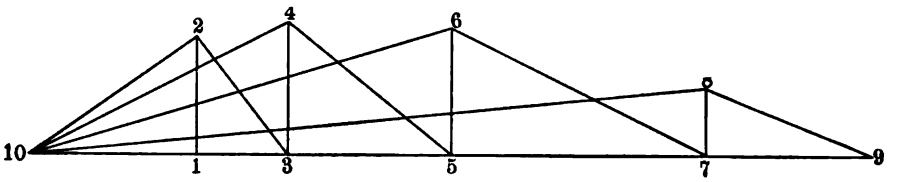

FIG. 49 (*b*).

the displacement diagram shown in Fig. (*c*). In this construction $E\,e$ is assumed to stand fast.

Member.	Length l.	u (Stress for $H = 1$).	$u\,l$.
AB	300	+ .538	161
BC	300	+1.50	450
CD	300	+3.00	900
DE	300	+4.00	1,200
ab	366	−1.220	446
bc	335	−1.720	577
cd	313	−2.610	817
de	301	−4.019	1,212
Aa	600	+ .70	420
Bb	390	+ .769	300
Cc	240	+ .750	180
Dd	150	+ .400	60
Ee	120	.....	....
Ab	492	− .883	434
Bc	384	−1.231	473
Cd	335	−1.677	562
De	323	−1.077	348

From the displacement diagram, the horizontal deflection of a is found to be equal to 20,000 (E being omitted in the calculations), or with respect to a' the deflection is 40,000. The vertical deflections are given in the table below. Dividing these values by 40,000 we get the following values of H for load unity at each joint:

Joint.	Deflection.	Value of H.
B	11,700	0.292
C	22,300	0.558
D	31,150	0.779
E	34,950	0.874

From these values the curve (or influence line) for H is plotted in Figs. (*d*), (*e*), and (*f*).

The stresses in the various members are then calculated by means of influence lines plotted as explained in Arts. 141 and 142. Fig. (*d*) shows the influence lines for upper-chord members, and Fig. (*e*) for the lower-chord members. For any chord member, then, the stress is equal to the respective

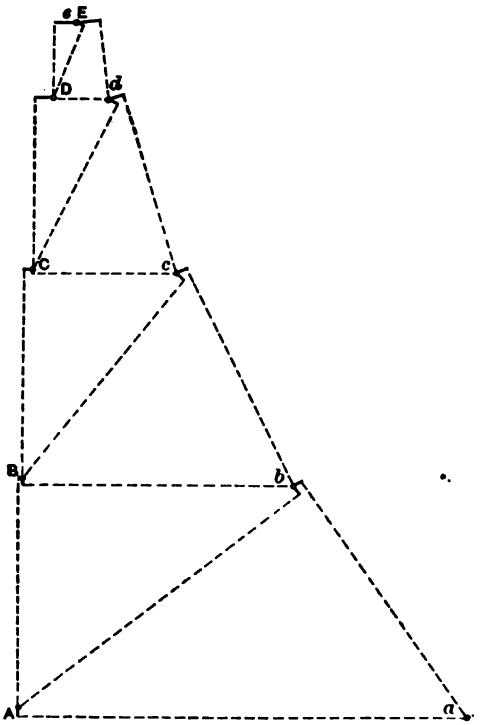

FIG. 49 (*c*).

influence line area, multiplied by y, the lever arm of the member in question, and by p, the load per foot.

Fig. (*f*) is the influence diagram for vertical component of stress in the diagonal members. The vert. comp. of stress in any diagonal is, then, load per foot multiplied by the respective influence line area, times the term y/l, which is the vertical distance from H to the moment center divided by the lever arm of the member in question.

The results of this analysis are given in Fig. (*g*) by the figures not enclosed in parentheses. The values given are the combined dead- and live-load stresses. From these stresses an approximate design has been made with sectional areas as shown in Fig. (*g*) by the numbers not in parentheses.

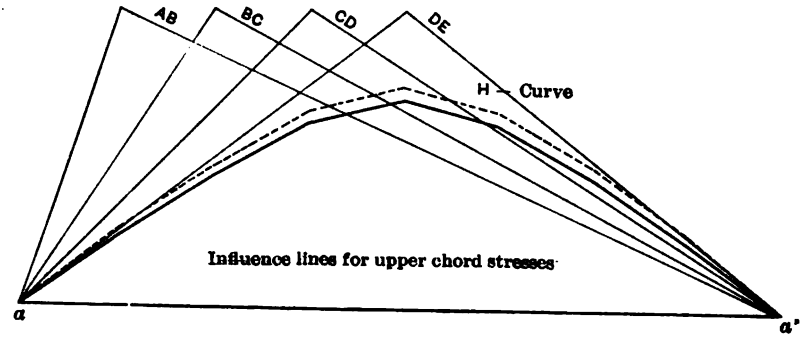

FIG. 49 (*d*).

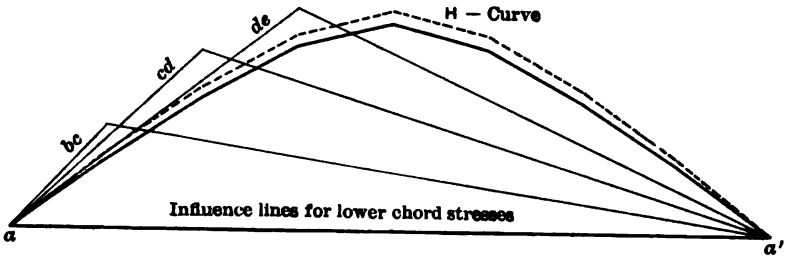

FIG. 49 (*e*).

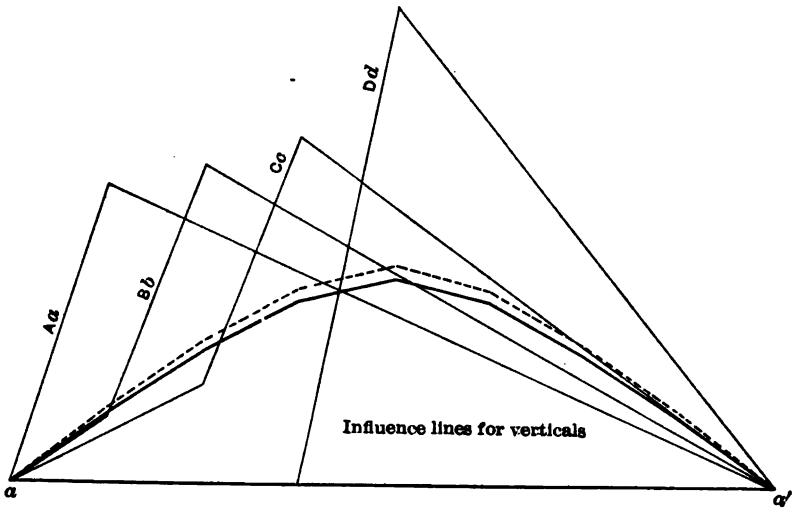

FIG. 49 (*f*).

In the calculations of the sectional areas, 50 per cent. was added to the live-load stresses for impact and the following working stresses used:

For tension members, 16,000 lbs. per sq. in.

For compression members, $16{,}000 - 70 \times l/r$ lbs. per sq. in.

(*b*) *Second Analysis.*—Having the sectional areas approximately determined, a more exact analysis may now be made by the same method used in the first analysis. The details of this will not be given.

New values of ul/A will need to be calculated and a new displacement diagram for $H = 1$ will be required. The resulting values of H were found to be larger than before, requiring a new curve for H to be plotted in Figs. (*d*), (*e*), and (*f*). The other lines of these diagrams remain the same. The stresses were then calculated using the new influence lines, and the sectional areas revised. In making up the revised areas, the stress used was the *average* of those obtained in the first and second analysis. It was found that in this

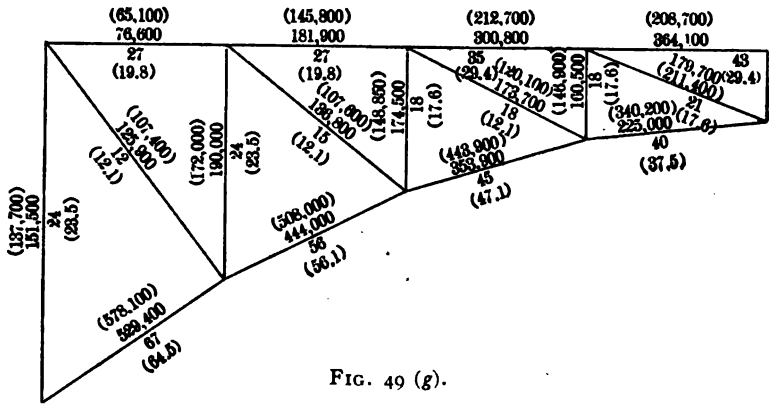

FIG. 49 (*g*).

way it was possible to get a very close agreement between the required area and area provided in the final design.

(*c*) *Third Analysis.*—Using the sectional areas as determined in the second analysis, new values of H were determined, and a new curve for H plotted in Figs. (*d*), (*e*), and (*f*). The new H curve is shown by the dotted lines in the figures. The stresses were again calculated, and it was found that the area provided agreed very closely with the area required in nearly all members. The final sections and stresses are as shown in parentheses in Fig. (*g*).

The final value of the deflection of point a with respect to a' was $1426.0/E$. The values of H are as given in the following table:

Joint	Deflection	Value of H.
B	456	0.320
C	865	0.607
D	1,205	0.845
E	1,365	0.957

d. Temperature Stresses.—The temperature stresses are very quickly found from the calculations already made. Using the final sections determined, the

displacement diagram gives a total deflection for $H = 1$, of $1426.0/E = 0.0000492$ in. A rise of temperature of 1° would cause an expansion, if unrestrained, of $.0000065 \times 200 \times 12 = .0156$ in. Hence such a change of temperature would develop a reaction of $H_t = .0156/0.0000492 = 317$ lbs. If a change of 60° is provided for the resulting H is $60 \times 317 = 19{,}000$ lbs. The stresses in the various members are obtained from the table, p. 161, by multiplying the several values of u there given by 19,000. It will be seen that in a few cases the temperature stresses exceed 25 per cent. of the total dead- and live-load stresses.

152.—Deflection of Two-Hinged Arches.—The formulas already developed may be applied to calculate the vertical (or horizontal) deflection at any point of an arch. The general formula for beams is $\Delta = \int \frac{M\,ds}{EI} \cdot m$, in which m is the bending moment due to a load unity applied at the given point and in the direction in which the deflection is desired.

It is generally convenient to calculate the deflection due to the vertical and the horizontal forces separately. Assuming the arch free to move horizontally at one end, the deflection from vertical forces will be

$$\Delta' = \int \frac{M'\,ds}{EI} \cdot m', \quad . \quad . \quad . \quad . \quad . \quad (36)$$

and from horizontal forces

$$\Delta'' = \int \frac{H\,y\,ds}{EI} \cdot m' = H \int \frac{y\,ds}{EI} \cdot m', \quad . \quad . \quad . \quad (37)$$

in which m' is the bending moment due to the one-pound load, arch considered as a simple beam. Now since $\int \frac{y\,ds}{EI} \cdot m'$ is the vertical deflection of the given point for one pound applied horizontally at the hinge, it is also equal to the horizontal deflection of the hinge for a one-pound vertical load applied at the given point, $= \delta_n$ of Art. 136. By that article the value of H for a one-pound load was shown to be equal to δ_n/δ, hence, eq. (37) reduces to $\Delta'' = H \times H_u\,\delta$, in which H is the total thrust for the given loading, H_u = thrust for one pound applied at the point whose deflection is desired, and δ = horizontal deflection of hinge for $H = 1$. This form of expression is advantageous, as the several values of H_u have already been calculated, and $\delta = \int \frac{y^2\,ds}{EI}$ of eq. (9). Note, further, that M' and m' of eq. (36) are equal to the moments in a simple straight beam.

Hence in case $\frac{ds}{I} = \text{constant} = \frac{dx}{I_o}$, we have $\Delta' = \frac{1}{E I_o} \int_o^l M' \, dx \, . \, m'$, which is the deflection of a straight beam of length l and moment of inertia I_o.

The deflections of an arch rib are much less than those of a straight beam of the same depth. They are greatest at about the quarter-point where the moments are a maximum. The value of Δ'', representing the effect of H, is of opposite sign from the term Δ'.

The deflections of braced arches are calculated by the same formula as used for simple trusses, $\Delta = \Sigma \frac{S u l}{E A}$. Here again the vertical and horizontal forces may conveniently be considered separately. The deflection curve determined in Art. 136 serves as the deflection curve for the horizontal forces. That for vertical forces is determined as in a simple span, algebraically or graphically.

The deflection of a two-hinged arch is somewhat less in general than a three-hinged arch, and much less than that of a simple truss of the same span.

153. Wind Stresses.—The lateral bracing of a two-hinged arch is arranged in the same manner as in the three-hinged arch (Art. 118), except that in this case the upper lateral system may be made continuous across the centre. Generally transverse bracing is used at each panel, as well as an upper and a lower lateral system, thus giving a redundant system. [Fig. 50 (*a*).]

The stresses in the upper lateral system and in the transverse bracing are determined by the same general method as explained in Art. 118 for the three-hinged arch. Without the transverse bracing the stresses in the upper laterals and end bracing are found as for a simple span. Also, if the upper laterals are omitted and the transverse bracing used, the stresses in the latter are readily found, as explained in Art. 118. Where both lateral systems and transverse bracing are used, the loads will be carried partly by one system and partly by the other. The depth of the transverse bracing at the centre being small, this bracing is relatively rigid at that point. The lower laterals are also generally more rigid than the upper laterals, especially where the arch is a plate-girder rib. Hence loads applied at joints near the centre will mainly be carried down the transverse bracing and along

the lower laterals. Loads applied at joints near the end, as at *d* and *g*, will be carried to a larger extent by the upper laterals, although the path *g G B* is likely to be more rigid than the path *g b B*. Again, the relative rigidity of the two paths depends much upon the size of the laterals themselves, and hence if a certain assumption is made as to the distribution of the loads and the laterals are designed

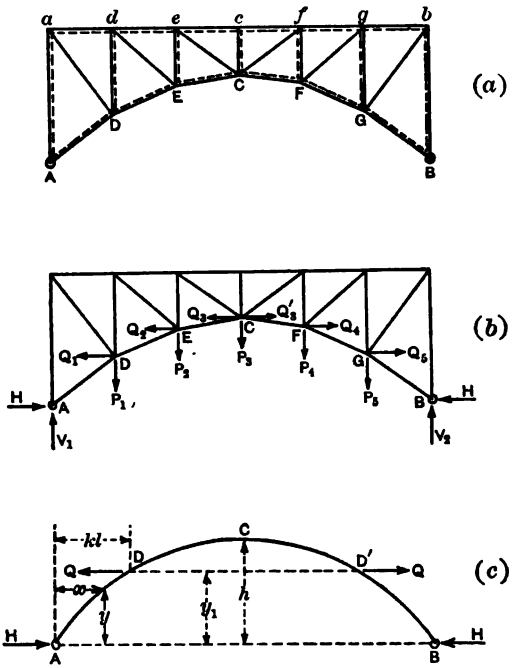

FIG. 50.

accordingly, their relative rigidities tend to follow the same proportions as those assumed in the distribution of the load. It will be safe and sufficiently accurate to design the more rigid path (the transverse bracing and lower laterals in this case) to carry, say, two-thirds or three-fourths of the total lateral pressure and the other system (the upper laterals) to carry the remainder. An exact analysis would require the application of the method of redundant members to the structure as a whole, and as there is one redundant lateral member

in each panel and one redundant member (or reaction) in each vertical truss, such a solution would be very laborious.

The loads transferred to the lower laterals having been estimated, these are combined with the loads acting directly thereon, and the shears and stresses in the lower lateral diagonals determined as in Art. 118. The resulting forces acting in the plane of the main truss are also to be determined as in that article (Fig. 33). The effect of these forces upon the main truss remains to be considered.

Fig. 50 (*b*) represents the leeward main truss, and the horizontal and vertical forces acting at the several joints due to the action of the transverse bracing and laterals. The problem is to determine the value of H for these forces in the same manner as for any other system of loads acting in the plane of the truss.

The value of H for the vertical loads P, for either the arch rib or the braced arch, is determined by methods already explained. The value of H for the horizontal forces Q is found by similar methods. In the case of the braced arch, the simplest method is to construct a displacement diagram of the truss for unit horizontal forces at A and B, as in Art. 136. Then from this diagram determine the horizontal displacement of the several joints D, E, etc., with respect to A. Then the horizontal displacement of any joint, divided by that of B, will equal the reaction H due to unit horizontal load at the joint in question. In this manner the values of H for ΣQ can be determined and the stresses then found.

If an arch rib is in question the value of H due to the horizontal loads Q requires the use of the general methods of Art. 119. Considering two equal symmetrical loads Q [Fig. (*c*)], acting at D and D', the resulting values of H will be equal to each other, as for vertical loads, and the vertical reactions will be zero. The bending moment at any section is then equal to $M' - H y$, as in eq. (4) of Art. 119, in which M' is the bending moment due to the forces Q with the reactions H removed. Finally, omitting the temperature term and also the term taking account of the effect of thrust, we have in general, as in eq. (9),

$$H = \frac{\int \frac{M' y \, ds}{I}}{\int \frac{y^2 \, ds}{I}} \quad . \quad . \quad . \quad . \quad . \quad . \quad . \quad (38)$$

Let $k\,l$ and y_1 be the coordinates of point D, referred to A as origin. In this case the value of M' for the portion $A\,D$ is zero, and for $D\,C$, $M' = Q\,(y - y_1)$, hence we have

$$\int \frac{M'\,y\,ds}{I} = 2\,Q \int_D^C \left(\frac{y^2\,ds}{I} - \frac{y_1\,y\,ds}{I}\right). \quad . \quad . \quad (39)$$

For the calculation of lateral stresses the arch may be assumed of parabolic form, and also that $\frac{ds}{I} = \frac{dx}{I_0}$, as in Art. 123. We also have $y = 4\,h\left(\frac{x}{l} - \frac{x^2}{l^2}\right)$. Substituting this value in (39) and integrating, we have

$$\int_D^C \frac{y^2\,ds}{I} = \frac{1}{I_0}\left[\frac{4}{15}\,h^2\,l - 16\,h^2\,l\left(\frac{k^3}{3} - \frac{k^4}{2} + \frac{k^5}{5}\right)\right]$$

and

$$\int_D^C \frac{y_1\,y\,ds}{I} = \frac{y_1}{I_0}\left[\frac{h\,l}{3} - 4\,h\,l\left(\frac{k^2}{2} - \frac{k^3}{3}\right)\right].$$

Also, as in Art. 124, $\int_A^B \frac{y^2\,ds}{I} = \frac{8\,h^2\,l}{15\,I_0}$. Substituting in (38) and reducing we get

$$H = Q\left[(1 - 20\,k^3 + 3\,k^4 - 12\,k^5) - \frac{y_1}{4\,h}(5 - 30\,k^2 + 20\,k^3)\right]. \quad . \quad (40)$$

By the application of eq. (40) for each of the pairs of loads Q, the final value of H is obtained and thence the stresses in the arch truss or rib.

SECTION IV.—ARCHES WITHOUT HINGES

154. General Formulas for Arch Ribs.—Let $A\,B$, Fig. 51, be a symmetrical arch, fixed at the ends and loaded in any manner. Suppose the arch to be cut at the crown C and let the stresses acting upon either half be represented as in Fig. 52. Then let

H_0, V_0, and M_0 = thrust, shear, and bending moment at the crown, considered as positive when acting as indicated;

T, V, and M = thrust, shear, and bending moment at any other section;

M' = bending moment at any section (Fig. 52) due to the external forces only (H_0, V_0, and M_0 being removed);

x, y = coordinates of any point referred to the point C as origin, x to be taken as positive toward the springing line in each half, and y as positive downward.

Then in general

$$M = M' + M_0 + H_0 y \pm V_0 x, \quad . \quad . \quad . \quad . \quad (1)$$

the plus sign being used for the right side and the minus sign for the left side. The values of M' are readily calculated by statics, but the

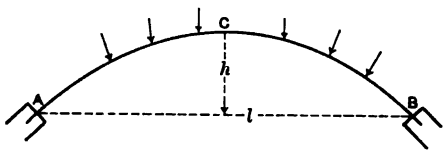

FIG. 51.

values of M_0, H_0, and V_0 cannot be so determined. They depend upon the form and material of the arch and require the establishing of three additional condition equations. These three equations are obtained by calculating the movement of point C of the left half

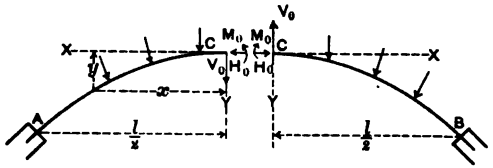

FIG. 52.

(Fig. 52), and placing it equal to the deflection of the same point for the right half.

If Δx, Δy, and $\Delta \varphi$ represent the horizontal and vertical components of the movement of C, and the change of angle at C, for the left half, and $\Delta' x$, $\Delta' y$, and $\Delta' \varphi$ the same quantities for the right half, we have, with due respect to sign,

$$\left.\begin{aligned} \Delta x &= -\Delta' x \\ \Delta y &= \Delta' y \\ \Delta \varphi &= -\Delta' \varphi \end{aligned}\right\} \quad . \quad . \quad . \quad . \quad . \quad . \quad . \quad (2)$$

Also from Arts. 99–100 we have, for the left half

$$\Delta x = \int \frac{M y\, ds}{EI}; \Delta y = -\int \frac{M x\, ds}{EI}; \Delta \varphi = \int \frac{M\, ds}{EI}. \quad (3)$$

The expressions for the right half are similar. Substituting in (2) and using the subscript l to represent left half and r to represent right half, we have

$$\left.\begin{aligned} \int \frac{M_l y\, ds}{EI} + \int \frac{M_r y\, ds}{EI} &= 0 \\ \int \frac{M_l x\, ds}{EI} - \int \frac{M_r x\, ds}{EI} &= 0 \\ \int \frac{M_l\, ds}{EI} + \int \frac{M_r\, ds}{EI} &= 0 \end{aligned}\right\} \quad (4)$$

Substituting the value of M from (1) and collecting terms we have the three general equations:

$$\left.\begin{aligned} \int \frac{M' y\, ds}{EI} + M_0 \int \frac{y\, ds}{EI} + H_0 \int \frac{y^2\, ds}{EI} &= 0 \\ \int \frac{M_l' x\, ds}{EI} - \int \frac{M_r' x\, ds}{EI} - V_0 \int \frac{x^2\, ds}{EI} &= 0 \\ \int \frac{M'\, ds}{EI} + M_0 \int \frac{ds}{EI} + H_0 \int \frac{y\, ds}{EI} &= 0 \end{aligned}\right\} \quad (5)$$

Solving for H_0, V_0, and M_0, and omitting E we derive the equations:

$$H_0 = \frac{\int \frac{ds}{I} \int \frac{M' y\, ds}{I} - \int \frac{M'\, ds}{I} \int \frac{y\, ds}{I}}{\left(\int \frac{y\, ds}{I}\right)^2 - \int \frac{ds}{I} \int \frac{y^2\, ds}{I}}. \quad (6)$$

$$V_0 = \frac{\int \frac{M_l'\, x\, ds}{I} - \int \frac{M_r' x\, ds}{I}}{\int \frac{x^2\, ds}{I}}. \quad (7)$$

$$M_0 = \frac{\int \frac{M'\, ds}{I} \int \frac{y^2\, ds}{I} - \int \frac{M' y\, ds}{I} \int \frac{y\, ds}{I}}{\left(\int \frac{y\, ds}{I}\right)^2 - \int \frac{ds}{I} \int \frac{y^2\, ds}{I}} = -\frac{H_0 \int \frac{y\, ds}{I} + \int \frac{M'\, ds}{I}}{\int \frac{ds}{I}}. \quad (8)$$

In these expressions all integrals excepting as noted by the subscripts l and r are to be taken for the entire arch, and the terms containing two integral signs indicate simply the product of the two separate integrals.

The foregoing expressions for H_o, V_o, and M_o are applicable to any form of arch rib or frame composed of a solid beam, but no account has here been taken of the effect of direct stresses upon the deformations. (See Section III, Chapter VI, for application of these formulas to rectanglar frames.)

To apply equations (6), (7), and (8) to any case where the integrations cannot be readily performed, the arch should be divided into numerous divisions of equal or unequal lengths and the process of summation used. All quantities are readily calculated for any given loading. The values of H_o, V_o, and M_o can thus be determined for single loads and influence lines plotted for fibre stress or shear.*

155. Temperature Stresses.—For a rise of temperature of t degrees, Δx of eq. (3) becomes equal to $\frac{\omega t l}{2}$, and $\Delta \varphi = 0$. Hence,

$$\int \frac{M y\, ds}{EI} = \omega t l, \text{ and } \int \frac{M\, ds}{EI} = 0. \quad . \quad . \quad . \quad (9)$$

In this case $M' = 0$ and $V_o = 0$; hence by substitution from (1) we have

$$M_o \int \frac{y\, ds}{EI} + H_o \int \frac{y^2\, ds}{EI} = \omega t l, \quad . \quad . \quad . \quad (10)$$

$$M_o \int \frac{ds}{EI} + H_o \int \frac{y\, ds}{EI} = 0, \quad . \quad . \quad . \quad . \quad (11)$$

from which we derive

$$H_o = \frac{\omega t l \int \frac{ds}{EI}}{\int \frac{ds}{EI} \int \frac{y^2\, ds}{EI} - \left(\int \frac{y\, ds}{EI} \right)^2}, \quad . \quad . \quad . \quad (12)$$

and

$$M_o = - \frac{H_o \int \frac{y\, ds}{I}}{\int \frac{ds}{I}}. \quad . \quad . \quad . \quad . \quad . \quad (13)$$

* For application of this method to reinforced concrete or masonry arches see Turneaure and Maurer, "Principles of Reinforced Concrete Construction."

The bending moment at any point is

$$M = M_0 + H_0 y. \quad . \quad . \quad . \quad . \quad . \quad . \quad . \quad (14)$$

156. Stresses Due to Shortening of Arch from Thrust.—As in Art. 119, eq. (7), the shortening due to thrust may be placed as equal approximately to $\frac{H_0 \cos \alpha_1 L}{E A_0}$. To take account of this element as in Art. 119, the first of eqs. (4) is placed equals to $\frac{H_0 \cos \alpha_1 L}{E A_0}$ instead of zero. This results in adding the term $+ \frac{L \cos \alpha_1}{A_0} \cdot \int \frac{ds}{I}$ to the denominator of eq. (6) for H, and $+ \frac{L \cos \alpha_1}{A_0} \int \frac{y\, ds}{I}$ to the denominator of the first expression for M_0 in eq. (8). The effect of thrust may, however, be conveniently taken care of as a correction or supplementary effect, in the same manner as temperature changes, in which case it is sufficiently accurate to use eqs. (12) and (13) for temperature effect by substituting $\frac{H_0 \cos \alpha_1 L}{E A_0}$ in place of $\omega t l$, giving, for effect of thrust alone,

$$H_s = - \frac{\frac{H \cos \alpha_1 L}{A_0} \int \frac{ds}{I}}{\int \frac{ds}{I} \int \frac{y^2 ds}{I} - \left(\int \frac{y\, ds}{I} \right)^2}, \quad . \quad . \quad (15)$$

in which H is the value of H_0 for the loaded condition, L = length of arch axis, A_0 = section at the crown, and α_1 = inclination at the springing line.

157. The Parabolic Arch with Variable Moment of Inertia.—As in Art. 123 formulas will be developed for a parabolic arch in which I varies with sec α so that $\frac{ds}{I} = \frac{dx}{I_0}$, I_0 being the moment of inertia at the crown.

158. *Stresses Due to a Single Vertical Load P.*—Let P, Fig. 53, be a single vertical load applied a distance b from the centre. The components of the reactions are H and V_1 at A, and H and V_2 at B. The moments at the supports are, respectively, M_1 and M_2. Let H_0, V_0, and M_0 refer to the crown C as before. The values of H_0, V_0, and M_0 will be

found by substituting in the general equations of Art. 154. The equation of the parabolic axis, origin at C, is $y = \frac{4hx^2}{l^2}$. For a single load P, arch cut at C, the moment M' exists only in the section $A\,D$.

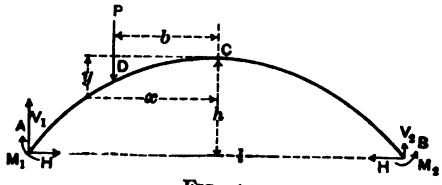

FIG. 53.

Here $M' = -P(x - b)$. Substituting the values of $\frac{ds}{I}$, y, and M' in the several integrals of eqs. (6), (7), and (8), there result the following values:

$$\int \frac{ds}{I} = \frac{l}{I_o}\,; \int \frac{y\,ds}{I} = \frac{8h}{l^2 I_o}\int_o^{\frac{l}{2}} x^2\,dx = \frac{hl}{3I_o};$$

$$\int \frac{y^2\,dx}{I} = \frac{2 \times 16\,h^2}{l^4 I_o}\int_o^{\frac{l}{2}} x^4\,dx = \frac{h^2 l}{5I_o};$$

$$\int \frac{x^2\,ds}{I} = \frac{2}{I_o}\int_o^{\frac{l}{2}} x^2\,dx = \frac{l^3}{12I_o};$$

$$\int \frac{M'\,ds}{I} = -\frac{P}{I_o}\int_b^{\frac{l}{2}} (x - b)\,dx = -\frac{P}{2I_o}\left(\frac{l}{2} - b\right)^2;$$

$$\int \frac{M'\,y\,ds}{I} = -\frac{4Ph}{l^2 I_o}\int_b^{\frac{l}{2}} (x-b)\,x^2\,dx = -\frac{Ph}{48l^2 I_o}(3l^4 - 8bl^3 + 16b^4);$$

$$\int \frac{M_1'\,x\,ds}{I} = -\frac{P}{I_o}\int_b^{\frac{l}{2}} (x - b)\,x\,dx = -\frac{P}{24I_o}(l^3 - 3bl^2 + 4b^3).$$

Substituting these values in eqs. (6), (7), and (8) and reducing, there result the following equations:

$$H_o = \frac{15l}{64h}\left(1 - \frac{4b^2}{l^2}\right)^2 P \quad \ldots\ldots\ldots \quad (16)$$

$$V_o = -\tfrac{1}{2}\left(1 + \frac{b}{l}\right)\left(1 - \frac{2b}{l}\right)^2 P \quad \ldots\ldots \quad (17)$$

$$M_o = l\left[\tfrac{1}{8}\left(1 - \frac{2b}{l}\right)^2 - \frac{5}{64}\left(1 - 4\frac{b^2}{l^2}\right)^2\right] P. \quad \ldots \quad (18)$$

Having H_o, V_o, and M_o, the value of M at any point is given by (1). The horizontal components of the reactions at A and B are, for vertical loads, equal to H_o. For a load on the left half

$$V_1 = V_o + P = \tfrac{1}{2}\left(1 - \frac{b}{l}\right)\left(1 + \frac{2b}{l}\right)^2 P \quad . \quad . \quad . \quad . \quad . \quad (19)$$

$$V_2 = -V_o \quad . \quad . \quad . \quad . \quad . \quad . \quad . \quad . \quad . \quad . \quad . \quad . \quad . \quad . \quad . \quad (20)$$

$$M_1 = M_o - P\left(\frac{l}{2} - b\right) + H_o h - V_o \frac{l}{2}$$

$$= \frac{l}{32}\left(1 + \frac{2b}{l}\right)^2\left[5\left(1 - \frac{2b}{l}\right)^2 - 4\left(1 - \frac{2b}{l}\right)\right]P \quad . \quad (21)$$

$$M_2 = M_o + H_o h + V_o \frac{l}{2}$$

$$= \frac{l}{32}\left(1 - \frac{2b}{l}\right)^2\left[5\left(1 + \frac{2b}{l}\right)^2 - 4\left(1 + \frac{2b}{l}\right)\right]P. \quad . \quad (22)$$

159. *Stresses Due to Changes of Temperature.*—Substituting in (12) we have, for a rise of temperature,

$$H_o = H_t = \frac{\omega t l \dfrac{l}{E I_o}}{\dfrac{l}{E I_o} \cdot \dfrac{h^2 l}{5 E I_o} - \dfrac{h^2 l^2}{9 E^2 I_o^2}} \quad . \quad . \quad . \quad (23)$$

$$M_o = -\frac{H_t \cdot \dfrac{h l}{3 I_o}}{\dfrac{l}{I_o}} = -\frac{H_t h}{3} \quad . \quad . \quad . \quad . \quad . \quad (24)$$

$$M_1 = M_2 = M_o + H_t h = \frac{2 H_t h}{3}. \quad . \quad . \quad . \quad . \quad . \quad (25)$$

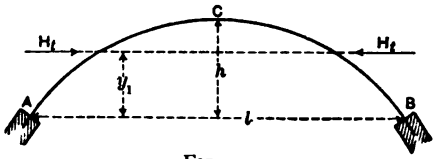

FIG. 54.

The reactions are equivalent to two forces equal to H_t, Fig. 54, applied a distance $y_1 = \frac{2}{3} h$, above the springing lines.

160. *Stresses Due to Shortening of Arch from Thrust.*—As in Art. 156 these may be calculated as a correction, by substituting $\frac{H \cos \alpha_1 L}{E A_o}$ for $\omega t l$ in (23), giving

$$H_s = -\frac{45 H I_o L \cos \alpha_1}{4 h^2 l A_o}, \quad . \quad . \quad . \quad . \quad . \quad (26)$$

in which H = thrust due to the given loading. The moments are given by (24) and (25).

161. *Reaction Lines for a Single Load.*—Fig. 55 gives the graphic analysis of forces for a single load P. $A'D'$ and $D'B'$ are the reaction lines or true equilibrium polygon. Fig. (*a*) is the force polygon, V_1,

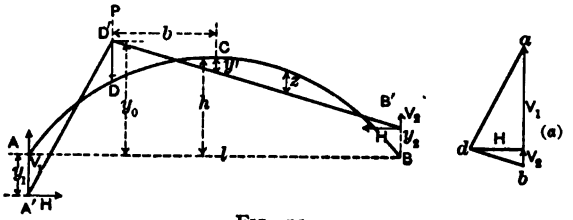

FIG. 55.

V_2, and H being the components of the reactions. There being a moment M_1 at A, the equilibrium polygon does not pass through A but some distance y_1 below, such that $H y_1 = M_1$. Likewise $H y_2 = M_2$. In a graphical treatment the ordinates y_1, y_o, and y_2 are conveniently treated as the unknowns, but the reaction lines $A'D'$ and $D'B'$ can readily be drawn from the values of H_o, V_o, and M_o as found in the preceding articles, as follows: Construct the force polygon by laying off $V_2 = -V_o$ and $H = H_o$. Then draw $D'B'$ parallel to $d\,b$ and at a distance y' above C (or below), such that $H_o y' = M_o$, or

$$y' = \frac{M_o}{H_o} = h \left[\frac{8}{15 \left(1 + \frac{2b}{l} \right)^2} - \frac{1}{3} \right]. \quad . \quad . \quad (27)$$

The line $A'D'$ is then drawn parallel to $a\,d$. The bending moment at any point is then given by the ordinate between the arch and the equilibrium polygon, multiplied by H.

The values of y_1, y_0, and y_2 are determined as follows:

$$y_1 = \frac{M_1}{H_0} = \frac{2h}{15}\left(\frac{l - 10b}{l - 2b}\right) \quad . \quad . \quad . \quad . \quad (28)$$

$$y_2 = \frac{M_2}{H_0} = \frac{2h}{15}\left(\frac{l + 10b}{l + 2b}\right). \quad . \quad . \quad . \quad . \quad (29)$$

By similar triangles $\frac{y_0 - y_1}{\frac{l}{2} - b} = \frac{V_1}{H_0}$, from which is derived, by substitution from (16), (19), and (28)

$$y_0 = \frac{6h}{5}. \quad . \quad . \quad . \quad . \quad . \quad . \quad . \quad . \quad (30)$$

The locus of the point D' is therefore a straight line whose ordinate $= \frac{6}{5}h$. Equations (28) to (30) enable the reaction lines to be readily drawn for a load at any point, and thence the moments, shears, and thrusts, if desired, due to this single load, from the equations:

$$\left.\begin{aligned} M &= H z \\ V &= V_1 \cos\alpha - H \sin\alpha \\ T &= V_1 \sin\alpha + H \cos\alpha \end{aligned}\right\} \quad . \quad . \quad . \quad . \quad . \quad (31)$$

The reaction lines on each side are all tangent to certain envelopes, $d\,e$ and $f\,g$ (Fig. 56). These envelopes are hyperbolas, tangent to each other at the centre and having vertical asymptotes through the springing lines.

162. *Position of Loads for Maximum Stress.*—In using reaction lines to find position of loads for a maximum stress it is convenient to construct the hyperbolic envelopes and the straight line locus $m\,n$ with $y_0 = \frac{6}{5}h$. This being done, the nature of the stress or moment caused by a load at any point is determined as in Art. 140. Thus in Fig. 56, the lines $G\,i$ and $G\,i'$, drawn tangent to $d\,e$ and $f\,g$ respectively, will determine the position of the loads for a maximum stress of either kind in $D\,E$, since loads between i and i' cause positive moment at G, while all other loads cause negative moment. Likewise a line drawn tangent to $d\,e$ and parallel to $F\,G$ and $D\,E$, or toward their intersec-

tion, will determine the position of loads for maximum stress of either kind in $D\,G$, as in Art. 140.

For an arch rib, the kern point, or flange centre, should be taken as the moment centre for maximum fibre stress.

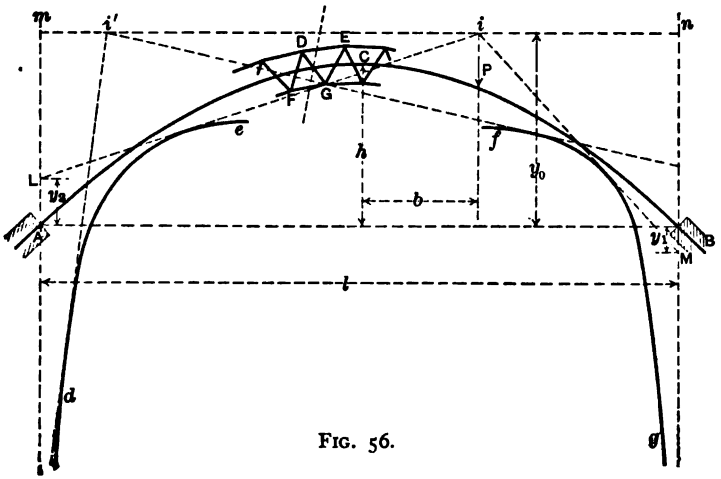

FIG. 56.

The following table, giving values of y_1/h and y_2/h for various load points, will enable enough reaction lines to be drawn to locate the envelopes with sufficient accuracy for the purpose.

VALUES OF $\frac{y_1}{h}$ AND $\frac{y_2}{h}$ FOR VARIOUS VALUES OF $\frac{b}{l}$.

(For loads on the right.)

$\frac{b}{l}$	$\frac{y_1}{h}$	$\frac{y_2}{h}$	$\frac{b}{l}$	$\frac{y_1}{h}$	$\frac{y_2}{h}$
0.50	$-\infty$	+0.400	0.25	−0.400	+0.311
0.45	−4.667	+0.386	0.20	−0.222	+0.286
0.40	−2.000	+0.370	0.15	−0.095	+0.256
0.35	−1.067	+0.353	0.10	0.0	+0.222
0.30	−0.667	+0.333	0.0	+0.133	+0.133

Having found the position of loads for a maximum stress the stresses may be found either graphically or algebraically. A convenient

method is to make use of the influence lines of H_o, V_o, and M_o, as described in the next Article.

163. *Influence Lines.*—If the method of influence lines is to be used it is convenient to first construct the influence lines for H_o, V_o, and M_o from eqs. (16), (17), and (18), Art. 158. It will be seen that the value of V_o depends only upon the position of the load $\left(\frac{b}{l}\right)$, not upon the rise or span length; M_o depends also upon the span length; while H_o depends upon both the span and rise. These quantities are, therefore, conveniently plotted for h and l = unity. The resulting curves are given in Fig. 57. These curves, therefore, serve as influence lines for these functions, for any arch of the type here considered, the true values of the functions being obtained by multiplying the ordinates of the curves by $\frac{l}{h}$ for H_o, and by l for M_o.

These influence lines may now be used to construct influence lines for moment at any other point by use of the general formula,

$$M = M_o + H_o y - V_o x - P(x - b). \quad . \quad . \quad . \quad (32)$$

where x and y are the coordinates of the point or moment centre in question. For values of $x < b$ the term $P(x - b)$ drops out.

If uniform loads are to be employed the position for a maximum is more readily found from the reaction lines. The position being known, the desired moment may then be found from the influence areas of Fig. 57.

164. Deflection of an Arch Rib.—The vertical deflection of any point is given by the general equation,

$$\Delta y = \int \frac{M x \, ds}{EI}. \quad . \quad . \quad . \quad . \quad . \quad . \quad . \quad (33)$$

where M is the true bending moment at any section due to the given loads. The abscissa x is to be measured from the point where the deflection is desired. The ends of the arch being fixed the deflection of any point is calculated by performing the integration (or summation) between either of the abutments and the point in question.

165. The Braced Arch Without Hinges.—Braced arches of small depth and parallel chords can be satisfactorily analyzed by treating

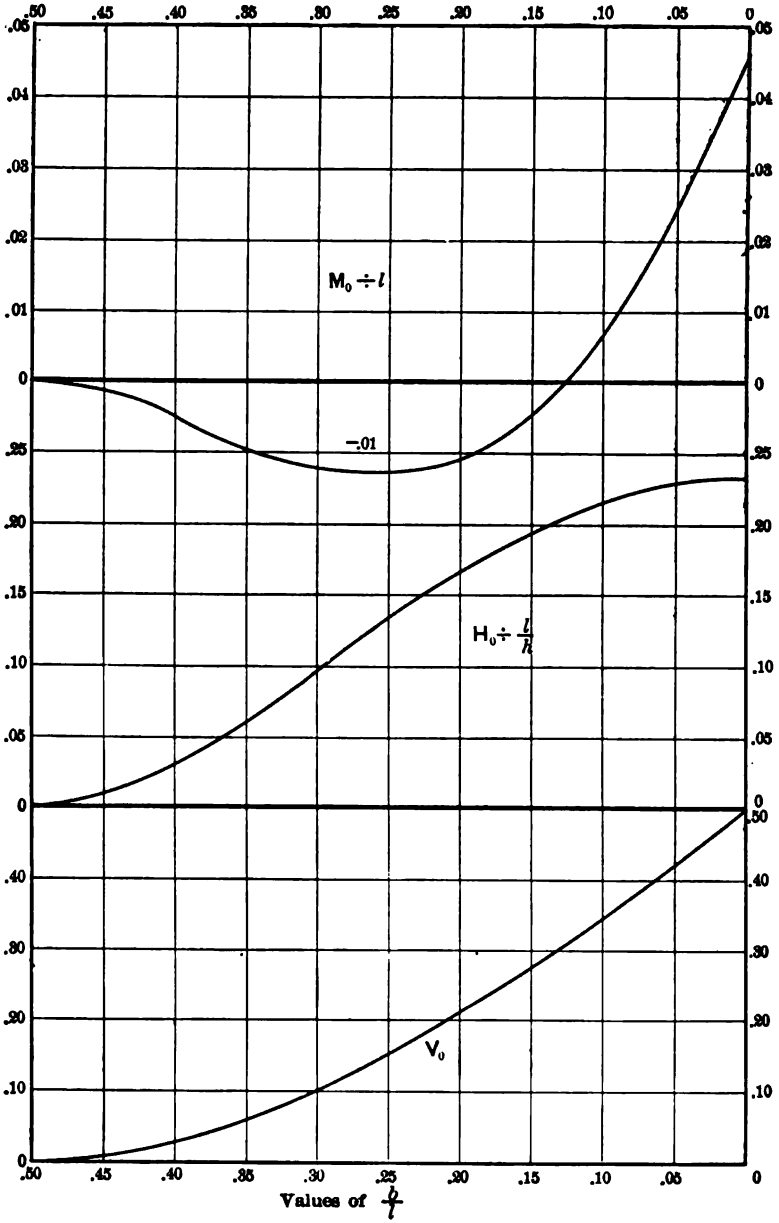
.50 .45 .40 .35 .30 .25 .20 .15 .10 .05 0
.05 .04 .03 .02 .01 0
$M_0 \div l$
−.01
$H_0 \div \frac{l}{h}$
0 .25 .20 .15 .10 .05 0
0 .50 .40 .30 .20 .10 0
V_0
.50 .45 .40 .35 .30 .25 .20 .15 .10 .05 0
Values of $\frac{h}{l}$

FIG. 57.

them as beams and using the methods already explained. Where the truss does not conform to these conditions the analysis must be made by the method of redundant members. If the truss is of the single intersection type the number of redundant members will be three, and the three equations of condition are found by placing equal to zero the relative displacement of the two cut ends of each redundant member, as explained in Part I, Art. 222. Any three members may be taken as the redundant members, provided they are so related that the remaining members form a structure that is stable and at the same time statically determinate.

Let Fig. 58 represent any braced arch without hinges. If members $B\,D$, $J\,L$, and $F\,H$ be omitted the structure becomes a three-hinged

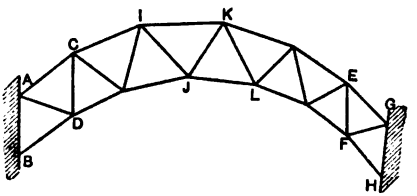

FIG. 58.

arch and therefore statically determinate. If three members at one end, as $E\,G$, $F\,G$, and $F\,H$, be omitted it becomes a cantilever supported at the left end and is again statically determinate. Or, again, three members at the crown or some intermediate section may be omitted, as $I\,K$, $J\,K$, and $J\,L$, dividing the structure into two cantilevers, as was done in the case of the arch rib (Art. 154). If the arch is a symmetrical one the last-named arrangement is likely to be the simplest. If a joint comes at the centre it is better for the sake of preserving symmetry to imagine the arch cut through the centre of the joint, and if a vertical member occurs at the centre to consider it as separated into two equal parts. Each half then may take the form shown in Fig. 59, and the problem is similar to that of the arch rib, Art. 154. Instead, however, of denoting the unknowns as a moment, shear and thrust, it will be more convenient to assume them as a shear V, and two horizontal forces, H_1 and H_2, these two forces being equivalent to the moment and thrust of Art. 154. The redundant forces are then V,

H_1, and H_2, and these are to be found by equating to zero the relative deflections of a and a' and b and b'. We proceed as in Art. 222, Part I.

Let S = stress in any member due to any given load, arch in normal condition;

S' = stress in any member due to the external loads, arch cut as shown in Fig. 59;

u_1 = stress in any member of either half due to a force $H_1 = 1$;

u_2 = same for a force of $H_2 = 1$;

u_3 = same for $V = 1$.

Then $$S = S' + H_1 u_1 + H_2 u_2 + V u_3. \quad . \quad . \quad . \quad . \quad . \quad . \quad . \quad (34)$$

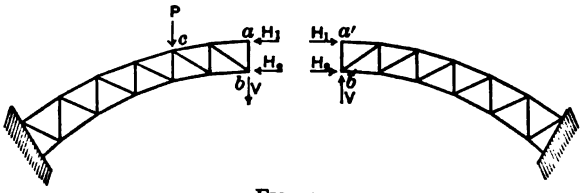

FIG. 59.

Now the horizontal deflection of b with respect to b' must be zero, and therefore we have

$$\Sigma \frac{S u_1 l}{A} = 0. \quad . \quad . \quad . \quad . \quad . \quad . \quad . \quad (35)$$

Likewise for the horizontal movement of a and a'

$$\Sigma \frac{S u_2 l}{A} = 0, \quad . \quad . \quad . \quad . \quad . \quad . \quad . \quad (36)$$

and for the vertical movement of b and b'

$$\Sigma \frac{S u_3 l}{A} = 0. \quad . \quad . \quad . \quad . \quad . \quad . \quad . \quad (37)$$

Substituting from (34) we derive the three linear equations

$$\left.\begin{aligned} \Sigma \frac{S' u_1 l}{A} + H_1 \Sigma \frac{u_1^2 l}{A} + H_2 \Sigma \frac{u_1 u_2 l}{A} + V \Sigma \frac{u_1 u_3 l}{A} &= 0 \\ \Sigma \frac{S' u_2 l}{A} + H_1 \Sigma \frac{u_1 u_2 l}{A} + H_2 \Sigma \frac{u_2^2 l}{A} + V \Sigma \frac{u_2 u_3 l}{A} &= 0 \\ \Sigma \frac{S' u_3 l}{A} + H_1 \Sigma \frac{u_1 u_3 l}{A} + H_2 \Sigma \frac{u_2 u_3 l}{A} + V \Sigma \frac{u_3^2 l}{A} &= 0 \end{aligned}\right\} . \quad (38)$$

The various summations are to be calculated, and their values being substituted the equations are readily solved for H_1, H_2, and V, whence all stresses become determinate.

166. *Graphical Method.*—The displacement diagram can be used to advantage in the calculation of the various summations above given, especially if the stresses are desired for a unit load at any joint, the same method being employed as in the example of Art. 151. In this case, however, three displacement diagrams are required. These are the following:

(1) A diagram for a one-pound load acting horizontally at a ($H_1 = 1$).

(2) A diagram for a one-pound load acting horizontally at b ($H_2 = 1$), and

(3) A diagram for a one-pound load acting vertically at b ($V = 1$).

These diagrams being drawn, measure thereon the following deflections with notation as given:

δ_a = horizontal deflection of a due to $H_1 = 1$, $\left(= \Sigma \frac{u_1^2 l}{A}\right)$;

δ_{bh} = horizontal deflection of b due to $H_2 = 1$, $\left(= \Sigma \frac{u_2^2 l}{A}\right)$;

δ_{bv} = vertical deflection of b due to $V = 1$, $\left(= \Sigma \frac{u_3^2 l}{A}\right)$;

δ'_a = horizontal deflection of a due to $H_2 = 1$, $\left(= \Sigma \frac{u_1 u_2 l}{A}\right)$;

δ''_a = horizontal deflection of a due to $V = 1$, $\left(= \Sigma \frac{u_1 u_3 l}{A}\right)$;

δ'_{bh} = horizontal deflection of b due to $V = 1$, $\left(= \Sigma \frac{u_2 u_3 l}{A}\right)$.

Consider a vertical load of unity at joint c. The various summations involving S' will then be as follows:

δ_c = vertical deflection of c for $H_1 = 1$, $\left(= \Sigma \frac{S' u_1 l}{A}\right)$;

δ'_c = vertical deflection of c for $H_2 = 1$, $\left(= \Sigma \frac{S' u_2 l}{A}\right)$;

δ''_c = vertical deflection of c for $V = 1$, $\left(= \Sigma \frac{S' u_3 l}{A}\right)$.

Substituting these several deflections in (38) we have

$$\left.\begin{aligned} \delta_c + 2\,\delta_a\,H_1 + 2\,\delta'_a\,H_2 + 2\,\delta''_a\,V &= 0 \\ \delta'_c + 2\,\delta'_a\,H_1 + 2\,\delta_{bh}\,H_2 + 2\,\delta'_{bh}\,V &= 0 \\ \delta''_c + 2\,\delta''_a\,H_1 + 2\,\delta'_{bh}\,H_2 + 2\,\delta_{bv}\,V &= 0 \end{aligned}\right\} . \quad . \quad (39)$$

For a unit load at any other joint the equations are the same, excepting the first term of each. The three displacement diagrams thus enable all desired values to be obtained for a load at any joint.

The values at H_1, H_2, and V being determined, the stress in any member is found from eq. (34), the values of S', u_1, u_2, and u_3 being already calculated.

167. *Temperature Stresses.*—For a change of temperature the horizontal deflections of a and $b = \frac{1}{2}\,\omega\,t\,l$. Hence the first and second of eq. (39) should be placed equal to $\omega\,t\,l$, δ_c being omitted. The value of V is also zero, since there is no shear at the centre, hence we have

$$\delta_a\,H_1 + \delta'_a\,H_2 = \omega\,t\,l$$

$$\delta'_a\,H_1 + \delta_{bh}\,H_2 = \omega\,t\,l$$

whence

$$H_1 = \omega\,t\,l\,\frac{\delta'_a - \delta_{bh}}{(\delta'_a)^2 - \delta_a\,\delta_{bh}} \quad . \quad . \quad . \quad . \quad . \quad (40)$$

and

$$H_2 = \omega\,t\,l\,\frac{\delta'_a - \delta_a}{(\delta'_a)^2 - \delta_a\,\delta_{bh}} \quad . \quad . \quad . \quad . \quad . \quad (41)$$

168. Wind Stresses.—The arch of no hinges is always constructed with chords parallel or nearly so, thus requiring the roadway to be supported on vertical struts, as in Figs. 1 and 5. Lateral bracing is therefore usually arranged as described in Art. 153, namely a lateral system along the roadway, vertical transverse bracing at each panel, and lower laterals along the arch. Inasmuch as both the upper and lower chords are fixed at the ends, the lower laterals may be placed along one or both chords and extend as a complete lateral system to the abutments. If two lines of laterals are used the upper one is preferably made of a sufficient size to carry the loads brought down from the roadway by means of the transverse bracing.

The shears in the laterals are determined as for the arch of two hinges, and the resulting vertical and horizontal forces acting upon the main arch also in like manner. These having been found, the stresses in the main arch are determined as for any other loads in the same plane.

169. Relative Advantages of the Arch with Fixed Ends.—Comparatively few arches have been constructed with fixed ends. As compared to the hinged types with parallel chords, the arch without hinges is somewhat more rigid and slightly more economical, especially where the dead load is relatively large. The difficulties of calculation are of some consequence, but where the chords are nearly parallel the use of the beam formulas for preliminary design will greatly facilitate the work.

Where a horizontal upper chord is desired the hingeless arch is not suitable, both on account of the difficulties of end supports and on account of the fact that with such a variable depth of truss the process of successive approximations in its design and analysis does not lead readily to consistent results. As pointed out more fully in Art. 251, a redundant system theoretically cannot be designed so that all members shall be stressed at the desired value. This is a case where the departure from assigned working stresses would be large in some members and hence to that extent result in an uneconomical form. The example of Art. 151 illustrates the difficulties of design and analysis for a two-hinged arch of this type. These would be much greater in the arch of no hinges. With chords nearly parallel, however, the structure approaches a beam in proportions, with much more uniform stresses in the chords and a more ready adjustment between stress and sectional areas.

CHAPTER V

SUSPENSION BRIDGES

170. Introduction.—Suspension Bridges may be classed under two main heads: (*a*) Those composed of a light platform suspended from a cable, the loads passing directly from the floor to the cable; (*b*) those consisting of a roadway supported by a truss which is hung from the cable by means of hangers.

Structures of the first class are called *Unstiffened Suspension Bridges.* Because of their lack of rigidity, structures of this class are limited to short spans and light loads. Heavy concentrations or unsymmetrical loads would distort the cable to such an extent as to cause excessive variation of grade in the roadway near the point of loading.

Structures of the second class are called *Stiffened Suspension Bridges.* The applied loads are taken up by the stiffening trusses and distributed to the cables by means of hangers. Due to the rigidity of the trusses, heavy concentrations or unsymmetrical loads are distributed over the cable approximately as a uniform load, so that it does not vary greatly from its original shape. Stiffened suspension bridges can be constructed rigid enough to carry railway or heavy city traffic.

In this chapter the cable as a structure by itself will be first considered. The unstiffened and the stiffened suspension bridge will then be taken up, and, for the usual conditions of loading, methods will be developed for the determination of the quantities necessary for the computation of stresses in such structures.

SECTION I.—THE CABLE

171. Form of the Cable.—*Any Loading.*—The form of the cable of a suspension bridge will depend upon the distribution of the applied loads. Any portion of the cable must be in equilibrium under the tensions at its ends and the loads. In any case, the form can be determined by drawing an equilibrium polygon for the applied loads,

subject to the condition that the polygon must pass through the points of attachment of the cable and some other fixed point, such as the lowest point of the curve.

172. *Load Uniform along the Horizontal.*—In Fig. 1, let w pounds per foot uniform load be carried by a cable passing through points A, B, and C. Required the form of the cable. As the weight of the applied loads is usually very much greater than the weight of the cable, the latter may be taken as uniformly distributed and included in the load w. Consider the uniform load w as divided into a series of concentrated loads Δx apart. Each load is $w \Delta x$ pounds. Then by drawing an equilibrium polygon for these loads, subject to the condition that the polygon must pass through the points A, B, and C, we have the form of the cable curve. The resulting force and equilibrium polygons are shown in Figs. 1 (a) and (b). The stress in the cable at any point is given by the corresponding ray of the force polygon. From the force and equilibrium polygons, certain relations exist from which we may find the equation of the cable curve. In Figs. (a) and (b) the triangles 3 4 M and O D F are similar, from which we obtain the following proportions:

$$H : \Delta x :: V_1 - \sum_1^3 w \Delta x : \Delta y, \quad . \quad . \quad . \quad . \quad (1)$$

and

$$H : \Delta x :: T : \Delta s. \quad . \quad . \quad . \quad . \quad . \quad . \quad (2)$$

From (1) we have

$$\frac{\Delta y}{\Delta x} = \frac{V_1 - \sum_1^3 w \Delta x}{H}, \quad . \quad . \quad . \quad . \quad . \quad . \quad (3)$$

and from (2)

$$T = H \frac{\Delta s}{\Delta x}. \quad . \quad . \quad . \quad . \quad . \quad . \quad . \quad (4)$$

If the distances Δx, Δy and Δs are very small we have, for an origin at point C

$$\frac{dy}{dx} = \frac{V_1 - \int_x^{\frac{l}{2}} w \, dx}{H}. \quad . \quad . \quad . \quad . \quad . \quad (5)$$

$$T = H \frac{ds}{dx}. \quad . \quad . \quad . \quad . \quad . \quad . \quad . \quad (6)$$

For the conditions shown in Fig. 1, $V_1 = \frac{wl}{2}$ and $\int_x^{\frac{l}{2}} w\,dx = \frac{wl}{2} - wx$. Substituting these values in eq. (5) we have

$$\frac{dy}{dx} = \frac{wx}{H}. \quad . \quad . \quad . \quad . \quad . \quad . \quad . \quad . \quad (7)$$

Integrating eq. (7) we find

$$y = \frac{wx^2}{2H}. \quad . \quad . \quad . \quad . \quad . \quad . \quad . \quad . \quad (8)$$

The value of H may be obtained from eq. (8) for $x = \frac{l}{2}$ and $y = f$, the sag of the cable, giving

$$H = \frac{wl^2}{8f}. \quad . \quad . \quad . \quad . \quad . \quad . \quad . \quad . \quad (9)$$

Equation (9) gives the value of H, the horizontal component of the cable stress. From the force polygon, Fig. (*b*), it can be seen that H is constant for all points of the cable. Substituting this value of H in eq. (8) we have

$$y = \frac{4fx^2}{l^2}, \quad . \quad . \quad . \quad . \quad . \quad . \quad . \quad (10)$$

which is the equation of the cable curve referred to point C as an origin. This is readily seen to be the equation of a parabola. Therefore a cable carrying a load uniformly distributed along the horizontal hangs in a curve which is a parabola. This also follows from the principle of graphics that the equilibrium polygon for uniform loads is a parabola.

For use in work to follow it will be convenient to refer the equation to coordinate axes with an origin at one of the supports, as A, and with the horizontal line $A\,B$ as the X axis. The equation then becomes

$$y = \frac{4fx}{l^2}(l - x). \quad . \quad . \quad . \quad . \quad . \quad . \quad (11)$$

Here y is the ordinate to the curve measured downward from the X axis at a point distance x from the origin, f being the sag or versine of the cable.

173. *Load Uniform Along the Cable.*—When the load on the cable

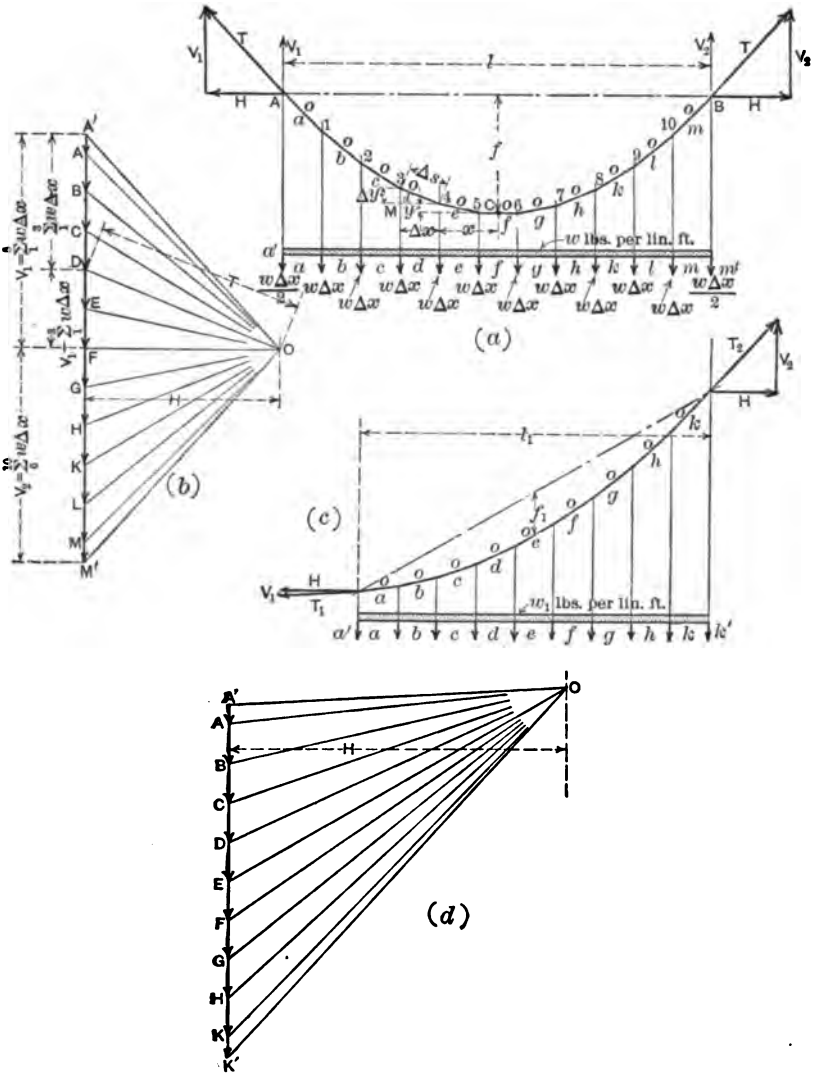

FIG. 1.

is due to its own weight, in which case the load is uniform per foot of length of cable, eq. (5) takes the form

$$\frac{dy}{dx} = \frac{V_1 - \int_{L_1}^{\frac{L}{2}} w\,ds}{H}, \quad \ldots\ldots \quad (12)$$

where w is the weight per foot of cable; L the length of the cable measured along its axis; L_1 the distance measured along the cable from the section in question to the origin of coordinates, again taken as point C; and ds an element of length of the cable. For this case

$$V_1 = \frac{wL}{2} \text{ and } w\int_{L_1}^{\frac{L}{2}} ds = w\int_{x}^{\frac{l}{2}} \left[1 + \left(\frac{dy}{dx}\right)^2\right]^{\frac{1}{2}} dx$$

Placing these values in eq. (12) and differentiating we have as the differential equation of the cable curve

$$\frac{d^2y}{dx^2} = -\frac{w}{H}\left[1 + \left(\frac{dy}{dx}\right)^2\right]^{\frac{1}{2}}, \quad \ldots\ldots \quad (13)$$

from which we obtain finally as the equation of the cable curve

$$y = \frac{1}{2c}\left[e^{cx} + e^{-cx} - 2\right], \quad \ldots\ldots \quad (14)$$

where $c = \frac{w}{H}$, or $\frac{1}{c}$ is the length of cable, of weight w per foot, whose weight is equal to H. In this equation y is the ordinate to the curve from a horizontal line through C, the low point, or centre, of the cable. Eq. (14) is the equation of a catenary. Therefore a cable under its own weight hangs in a catenary. As c in eq. (14) depends upon H and w for its value, it can be seen that unless these are known beforehand, the equation can be solved only by successive approximations.

When the sag is very small compared to the span, ds and dx in eq. (12) are approximately equal, and the resulting equation is again of the parabolic form as given by eq. (10).

Eq. (14) may also be expressed in terms of hyperbolic functions. Thus we have

$$y = \frac{1}{c}\left[\frac{e^{cx} + e^{-cx}}{2} - 1\right] = \frac{1}{c}\left[(\cosh cx) - 1\right]. \quad \ldots \quad (15)$$

174. *Side Spans.*—When the structure has side spans which are also suspended from the cable, the loads again being taken as uniformly distributed along the horizontal, we can proceed as before to draw the force and equilibrium polygons and determine the equation of the cable curve. Figs. 1 (*c*) and (*d*) show the force and equilibrium polygons. The cable hangs in a parabolic curve, whose equation referred to point A as origin is

$$y_1 = \frac{4 f_1 x_1}{l_1^2} (l_1 - x_1). \quad . \quad . \quad . \quad . \quad . \quad . \quad (16)$$

Here y_1 is measured vertically from the line $A\ D$ to the cable curve, as shown in Fig. 2; f_1 is the sag at the span centre; l_1 is the span length;

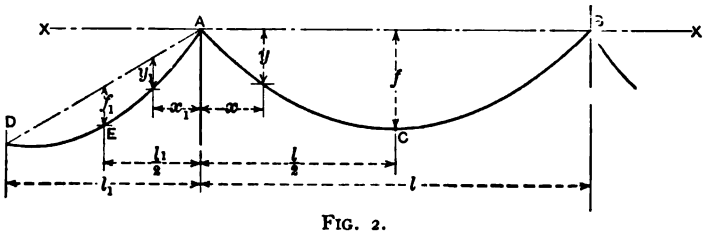

FIG. 2.

x_1 is the horizontal distance from A to any point on the curve. The notation is fully shown in Fig. 2.

175. *Unsymmetrical Spans.*—Sometimes, in the case of light foot bridges, the tops of the towers are not placed at the same elevation.

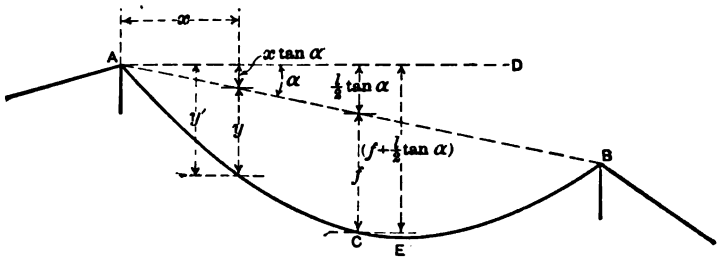

FIG. 3.

In such a case the methods used in the last article may again be applied. The equation of the curve (Fig. 3), referred to A as origin, and $A\ B$, a line joining the tops of the towers, is $y = \frac{4fx}{l^2}(l - x)$. The

equation may also be referred to a horizontal line $A\,D$, the origin remaining at A. If the line $A\,B$ joining the tops of the towers makes an angle α with the horizontal, the equation of the curve is

$$y' = y + x \tan \alpha = \frac{4 f x}{l^2}(l - x) + x \tan \alpha. \quad . \quad (17)$$

The lowest point in the curve is no longer at the span centre but is at E, a little to one side of the centre. Its location may be found by differentiating the above equation, placing the result equal to zero, and solving for x. We then have

$$x_E = \frac{l}{2}\left(1 + \frac{l}{4f}\tan \alpha\right).$$

176. Length of the Cable.—*Main Span. Parabolic Cable.*—From Fig. 1 (*a*) it can be seen that the length of an element of the cable curve is given by the expression

$$d s = (d x^2 + d y^2)^{\frac{1}{2}} = \left[1 + \left(\frac{d y}{d x}\right)^2\right]^{\frac{1}{2}} d x.$$

If L is the length of the cable, we then have

$$L = \int_0^l \left[1 + \left(\frac{d y}{d x}\right)^2\right]^{\frac{1}{2}} d x. \quad . \quad . \quad . \quad . \quad (18)$$

In performing the above integration for a parabolic cable it is somewhat easier to use the equation in the form given in eq. (10): $y = \frac{4 f x^2}{l^2}$. Substituting the value of $\frac{d y}{d x}$ as obtained from this equation in eq. (18), we have

$$L = 2\int_0^{\frac{l}{2}} \left[1 + \frac{64 f^2 x^2}{l^4}\right]^{\frac{1}{2}} d x$$

$$= \frac{l}{2}\left(1 + \frac{16 f^2}{l^2}\right)^{\frac{1}{2}} + \frac{l^2}{8 f}\log_e \left[\frac{4 f}{l} + \left(1 + \frac{16 f^2}{l^2}\right)^{\frac{1}{2}}\right]. \quad . \quad (19)$$

This equation gives the exact length of the curve from A to B, Fig. 1 (*a*).

By making use of certain well-known properties of the parabola, eq. (19) may be written in the form (Fig. 4)

$$L = \left[2 A E + \frac{l^2}{8 f}\log_e \cot \frac{(90° - \beta)}{2}\right]. \quad . \quad . \quad (20)$$

As shown in Fig. 4, $A\,D$ is the tangent to the parabola at A while $\beta = \tan^{-1}\frac{4f}{l}$, where β is the angle between the above tangent and the horizontal. The chord $A\,E$ is half the length of the tangent $A\,D, = \left[f^2 + \left(\frac{l}{4}\right)^2\right]^{\frac{1}{2}}$.

An approximate value of length of curve may be obtained by expanding the term $\left[1 + \frac{64\,f^2\,x^2}{l^4}\right]^{\frac{1}{2}}$ of eq. (19) by means of the

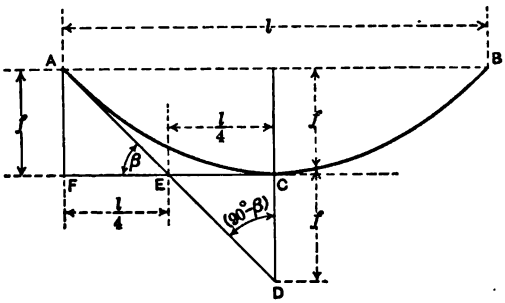

FIG. 4.

binomial formula and integrating the resulting expression. We then have

$$L = 2\int_0^{\frac{l}{2}} \left(1 + \frac{32\,f^2\,x^2}{l^4} - \frac{512\,f^4\,x^4}{l^8} + \ldots\right) dx$$

$$= l\left(1 + \frac{8}{3}n^2 - \frac{32}{5}n^4 + \ldots\right), \quad . \quad . \quad . \quad . \quad . \quad (21)$$

where $n = \frac{f}{l}$, the sag ratio. The value given in eq. (21) is sufficiently accurate for most cases. When the sag ratio is small, say not greater than $\frac{1}{10}$, eq. (21) may be written

$$L = l\left(1 + \frac{8}{3}n^2\right). \quad . \quad . \quad . \quad . \quad . \quad (21\,a)$$

177. *Main Span. Catenary.*—For the cable hanging under its

own weight, when the curve is a catenary, as given by eq. (14), we have

$$L = 2\int_0^{\frac{l}{2}} \left[1 + \left(\frac{dy}{dx}\right)^2\right]^{\frac{1}{2}} dx = 2\int_0^{\frac{l}{2}} \tfrac{1}{2}\left(e^{cx} + e^{-cx}\right) dx$$

$$= \frac{1}{c}\left(e^{\frac{cl}{2}} - e^{-\frac{cl}{2}}\right). \quad \ldots \quad (22)$$

Expressed in hyperbolic functions, this becomes

$$L = \frac{2}{c}\left(\frac{e^{\frac{cl}{2}} - e^{-\frac{cl}{2}}}{2}\right) = \frac{2}{c}\sinh\frac{cl}{2}. \quad \ldots \quad (23)$$

Results for the side spans may be determined as in the case of the parabolic cable, Art. 178.

178. *Side Spans. Parabolic Cable.*—For the length of the side span curves, the methods used above must be modified somewhat, as it is not possible to use directly the equation for the side spans given in

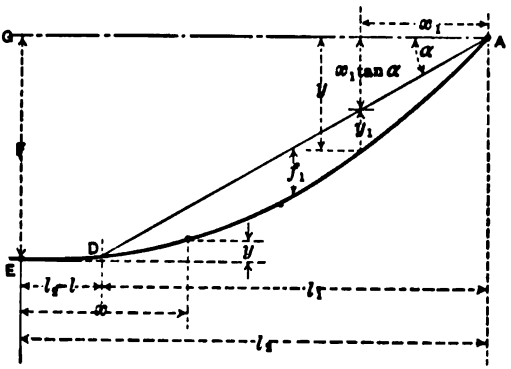

FIG. 5.

(16). Expressions for length, similar to (19) and (20), can be obtained by referring the equation to the true vertex of the curve, shown at point E, Fig. 5, which in most cases will be found outside point D. From the equation of the side span cable curve referred to point E as origin, which is $y = \frac{F x^2}{l_2^2}$ with the notation shown in Fig. 5, the length $A\,D$ is found to be

$$A\,D = \int_{l_2 - l_1}^{l_2} \left[1 + \frac{4F^2x^2}{l_2^4}\right]^{\frac{1}{2}} dx. \quad \ldots \quad (24)$$

An approximate result, similar to that given in eq. (21) may also be obtained for the curve with origin at E. Approximate results may also be obtained by using the equation of the curve in the form given by eq. (17). Thus with the origin at A, Fig. 5, the X axis being the line $A\,G$, the equation is

$$y = \frac{4 f_1 x_1}{l_1^2}(l_1 - x_1) + x_1 \tan \alpha.$$

Then proceeding as in the derivation of eq. (21) we have

$$L = l_1\left[1 + \frac{8}{3} n_1^2 - \frac{32}{5} n_1^4 + \tfrac{1}{2}(1 - 8 n_1^2)\tan^2 \alpha - \tfrac{1}{8}\tan^4 \alpha\right] \quad (25)$$

For small sag ratios this equation may be written

$$L = l_1\left(1 + \frac{8}{3} n_1^2 + \tfrac{1}{2}\tan^2 \alpha\right). \quad . \quad . \quad . \quad (25a)$$

179. Stresses in the Cable for Uniform Loads.—*Parabolic Cable.*—The stress in a cable carrying a uniformly distributed horizontal load may be determined by taking a section at any point in the cable and

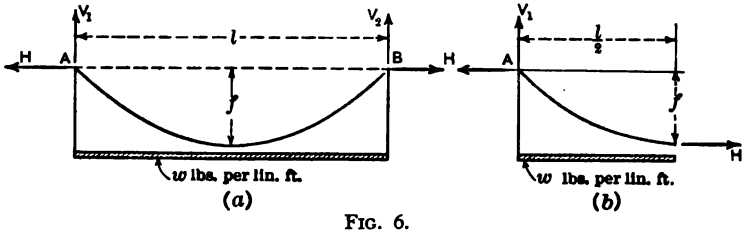

FIG. 6.

equating moments of forces on either side of the section equal to zero. This uniform load may be due to the weight of a suspended platform or to a live load covering the whole span.

In Fig. 6 (*a*) is shown a cable of span l, and sag f, carrying a uniform horizontal load of w lbs. per ft.

A section is cut at the centre of the span and the portion to the left removed, together with all forces acting upon it, as shown in Fig. 6 (*b*). A moment equation about A gives $-Hf + \frac{wl^2}{8} = 0$, from which we have $H = \frac{wl^2}{8f}$. This is the same result as given by eq. (9). When the load on the cable is due to a uniformly distributed

live load of p lbs. per ft. in addition to the dead load of w lbs. per ft., eq. (5) becomes

$$H = (w + p)\frac{l^2}{8f}. \quad . \quad . \quad . \quad . \quad . \quad . \quad . \quad (26)$$

Eq. (26) gives the horizontal component of the cable stress at any point. The stress at any point is given by eq. (6):—

$$T = H\frac{ds}{dx} = H\left[1 + \left(\frac{dy}{dx}\right)^2\right]^{\frac{1}{2}}.$$

Substituting the value of $\frac{dy}{dx}$ as given by the equation of the parabola referred to point C as origin, eq. (10), we have

$$T = H\left[1 + \frac{64f^2}{l^4}x^2\right]^{\frac{1}{2}}. \quad . \quad . \quad . \quad . \quad . \quad (27)$$

At the span centre, where $x = 0$, we have $T = H$, and at the support, where $x = \frac{l}{2}$, we have the maximum value of the cable stress or

$$T = H\left[1 + \frac{16f^2}{l^2}\right]^{\frac{1}{2}} \quad . \quad . \quad . \quad . \quad . \quad . \quad . \quad (28)$$

The stresses in the cable of a side span may be determined in the same way. Figs. 7 (*a*) and (*b*) show the conditions. Moments about point A, Fig. (*b*), gives $H_1 f_1 \cos \alpha_1 - \frac{w_1 l_1^2}{8} = 0$, from which we have $H_1 = \frac{w_1 l_1^2}{8 f_1} \sec \alpha_1$. The horizontal component of the cable stress is then

$$H = H_1 \cos \alpha_1 = \frac{w_1 l_1^2}{8 f_1}. \quad . \quad . \quad . \quad . \quad . \quad (29)$$

The stress at any point in the cable may be found from eq. (6):

$$T = H\frac{ds}{dx} = H\left[1 + \left(\frac{dy}{dx}\right)^2\right]^{\frac{1}{2}}.$$

The value of $\frac{dy}{dx}$ is to be taken for the equation of the side span curve expressed in the form of eq. (17), from which

$$\frac{dy}{dx} = \frac{4f_1}{l_1^2}(l_1 - 2x) + \tan \alpha_1.$$

We then have

$$T = H \left\{ 1 + \left[\tan \alpha_1 + \frac{4 f_1}{l_1^2} (l_1 - 2x) \right]^2 \right\}^{\frac{1}{2}} . \quad . \quad (30)$$

At the span centre, where $x = \frac{l}{2}$

$$T = H [1 + \tan \alpha_1^2]^{\frac{1}{2}}, \quad . \quad . \quad . \quad . \quad . \quad (31)$$

and at the support, where $x = 0$

$$T = H \left[1 + \left(\tan \alpha_1 + \frac{4 f_1}{l_1} \right)^2 \right]^{\frac{1}{2}}, \quad . \quad . \quad . \quad (32)$$

which is the maximum stress in the cable.

From eqs. (25) and (29) we can determine the relation between

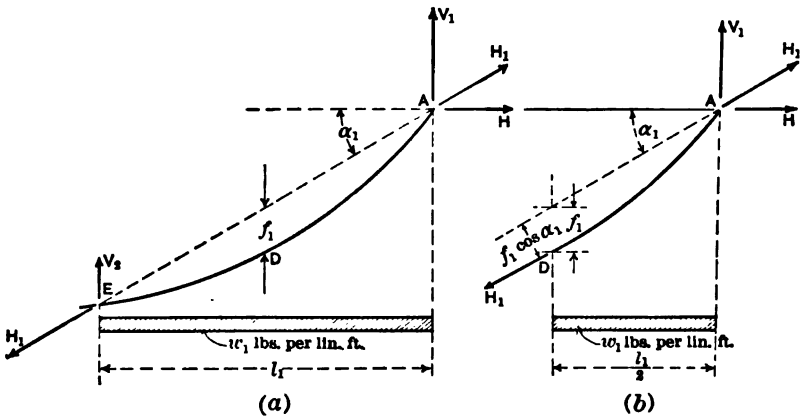

FIG. 7.

sags in the main and side spans for equal values of H at all points. We have

$$\frac{w l^2}{8 f} = \frac{w_1 l_1^2}{8 f_1} \text{ or } \frac{f_1}{f} = \frac{w_1 l_1^2}{w l^2} \quad . \quad . \quad . \quad . \quad . \quad (33)$$

180. *Catenary Cable.*—When the load is considered as uniformly distributed along the cable, as in the catenary, the stress at any point is again $T = H \frac{d s}{d x}$.

Here $H = \frac{w}{c}$ and $ds = \left[1 + \left(\frac{dy}{dx}\right)^2\right]^{\frac{1}{2}} dx$ and we have $T = \frac{w}{c}\left[1 + \left(\frac{dy}{dx}\right)^2\right]^{\frac{1}{2}}$. Substituting the value of $\frac{dy}{dx}$ as found from eq. (14) we have

$$T = \frac{w}{2c}(e^{cx} + e^{-cx}). \quad . \quad . \quad . \quad . \quad . \quad . \quad (34)$$

When $x = 0$ in eq. (34), $T = \frac{w}{c} = H$ and when $x = \frac{l}{2}$, or at the supports

$$T = \frac{w}{2c}\left(e^{\frac{cl}{2}} + e^{-\frac{cl}{2}}\right). \quad . \quad . \quad . \quad . \quad . \quad . \quad (35)$$

Eqs. (34) and (35) may be expressed in terms by hyperbolic functions. Thus eq. (34) becomes

$$T = \frac{w}{c}\left(\frac{e^{cx} + e^{-cx}}{2}\right) = H \cosh cx \quad . \quad . \quad . \quad (36)$$

In the same way eq. (35) becomes

$$T = H \cosh \frac{cl}{2} \quad . \quad . \quad . \quad . \quad . \quad . \quad . \quad (37)$$

Again eq. (34) may be written

$$T = \frac{w}{2c}(e^{cx} + e^{-cx}) = w\left(y + \frac{1}{c}\right) = wy + H \quad . \quad (38)$$

That is, the stress in the cable at any point is equal to the horizontal component of cable stress, H, plus the product of the ordinate to the cable curve at the point in question and the weight of the cable per foot of length. At the span centre, where $y = 0$, in eq. (38), we have $T = H$ as before, and at the supports, where $y = f$, the sag of the cable, we have

$$T = (wf + H) \quad . \quad . \quad . \quad . \quad . \quad . \quad . \quad (39)$$

181. Deformation of the Cable.—In some cases a change in span length or in the centre sag may occur due to temperature or stress changes. It is then necessary to know what effect this change will have on other dependent quantities.

For the parabolic cable, whose length is given by eqs. (19) and (21), the length, L, is given in terms of two dependent variables; f the sag,

and l the span length. By partial differentiation of eq. (19) we have

$$dL = \frac{l}{2f}\left\{\left(1 + \frac{16f^2}{l^2}\right)^{\frac{1}{2}} - \frac{l}{4f}\log_e\left[\frac{4f}{l} + \left(1 + \frac{16f^2}{l^2}\right)^{\frac{1}{2}}\right]\right\}df \quad (40)$$

Eq. (40) shows the change in cable length for a small change in the sag, the span length remaining constant. In the same way we find

$$dL = \frac{l}{4f}\log_e\left[\frac{4f}{l} + \left(1 + \frac{16f^2}{l^2}\right)^{\frac{1}{2}}\right]dl \quad . \quad . \quad (41)$$

Eq. (41) shows the change in cable length for a small change in span length, the sag remaining constant. Then from eq. (40) and eq. (41) we have

$$dl = \left\{\frac{2\left(1 + \frac{16f^2}{l^2}\right)^{\frac{1}{2}}}{\log_e\left[\frac{4f}{l} + \left(1 + \frac{16f^2}{l^2}\right)^{\frac{1}{2}}\right]} - \frac{l}{2f}\right\}df. \quad . \quad (42)$$

Eq. (40) shows the change in span length for a small change in the centre sag. The values given in eqs. (40), (41), and (42) are exact values for these expressions. Approximate values for these same expressions may be determined from eq. (21). We have:

$$dL = \frac{1}{15}(15 - 40n^2 + 288n^4)\,dl. \quad . \quad . \quad . \quad (43)$$

$$dL = \frac{16}{15}n(5 - 24n^2)\,df. \quad . \quad . \quad . \quad . \quad . \quad . \quad (44)$$

and from eqs. (43) and (44)

$$dl = \frac{16n(5 - 24n^2)}{(15 - 40n^2 + 288n^4)}\,df. \quad . \quad . \quad . \quad . \quad (45)$$

For a change in temperature of t degrees, coefficient of expansion ω, the length of the cable, L, is altered by an amount

$$dL = \omega t L \quad . \quad . \quad . \quad . \quad . \quad . \quad . \quad (46)$$

Inserting this value of dL in eqs. (40) and (41) or (43) and (44), exact or approximate values can be found for the corresponding changes in the sag or span length.

From the expression for stress at any point in the cable under uniform load, $T = \frac{p\,l^2}{8f}\left[1 + \frac{64\,f^2\,x^2}{l^4}\right)^{\frac{1}{2}}$, we find by differentiating

$$dT = -\frac{H}{f}\left(1 + \frac{64\,f^2\,x^2}{l^4}\right)^{-\frac{1}{2}} df,$$

or

$$df = -\frac{f}{H}\left(1 + \frac{64\,f^2\,x^2}{l^4}\right)^{\frac{1}{2}} dT = -\frac{f}{H}\,dH. \quad . \quad (47)$$

which gives the change in sag due to a small change in cable stress. Then from eqs. (40) and (42), or (44) and (45), the corresponding changes in the length of the cable or the span length may be found.

Section II.—Unstiffened Suspension Bridges

182. Introduction.—Unstiffened Suspension Bridges are usually built in the form shown in Fig. 8. The cable passes over two towers and is anchored by back stays to a firm foundation. The roadway

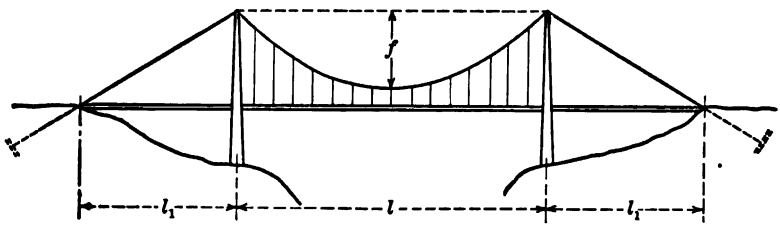

Fig. 8.

platform is suspended from the cable by means of hangers. In early structures of this type, the cable consisted of a built-up chain. After iron and steel wire came into use, wire cables of uniform cross-section were used in place of chains.

183. Stresses in the Cable.—The load to be carried by the cable consists of the weight of the cable and hangers, the weight of the platform or roadway, and the live load. As the cable is light compared to the weight of the roadway, its weight may be considered as uniformly distributed along the horizontal. For the same reason the weight of the hangers may also be considered as a uniform load. Let this total

dead weight be w lbs. per lin. ft. Then we have the same conditions for the cable considered by itself, as in Art. 179. From this article we find that the cable curve is a parabola, and that the maximum dead-load stress, which occurs at the towers, is

$$T_w = \frac{w l^2}{8 f}\left[1 + \frac{16 f^2}{l^2}\right]^{\frac{1}{2}}. \quad . \quad . \quad . \quad . \quad . \quad (1)$$

where f is the sag of the cable at the centre and l the span length, as shown in Fig. 8.

For a uniform live load of p lbs. per lin. ft., on the roadway, it is evident that the maximum cable stress will occur when the load covers the whole span. Then the maximum stress, which is at the towers, is

$$T_p = p\frac{l^2}{8 f}\left[1 + \frac{16 f^2}{l^2}\right]^{\frac{1}{2}}. \quad . \quad . \quad . \quad . \quad . \quad . \quad (2)$$

The total stress is the sum of the values given in eqs. (1) and (2) or

$$T_{(w+p)} = \frac{(w + p)\, l^2}{8 f}\left[1 + \frac{16 f^2}{l^2}\right]^{\frac{1}{2}}. \quad . \quad . \quad . \quad . \quad (3)$$

184. Deformation of the Cable under Partial Loading.—*Live loads on One End.*—Under an unsymmetrical load the cable will be deflected out of its parabolic form. The low point in the cable curve does not remain at the span centre, but shifts toward the loaded side. The shape of the cable may be determined by drawing an equilibrium polygon as explained in Art. 172. It may also be found by passing a section at any point in the cable and determining the equation of the cable curve. From this equation we may determine the resulting deformation. In Fig. 9 (*a*) is shown an unstiffened suspension bridge carrying the weight of the roadway, etc., of w lbs. per lin. ft., and a live load of p lbs. per lin. ft., extending a distance $k\,l$ from the left end of the span. The original position of the cable is shown by the dotted line, the heavy line showing the deformed position. It is evident that the new cable curve will consist of two parabolas which will coincide at the head of the live load. The equations of these two parabolas will now be determined.

Cutting a section at a point distance x from the left end and indicating all forces, the conditions are as shown in Fig. 10.

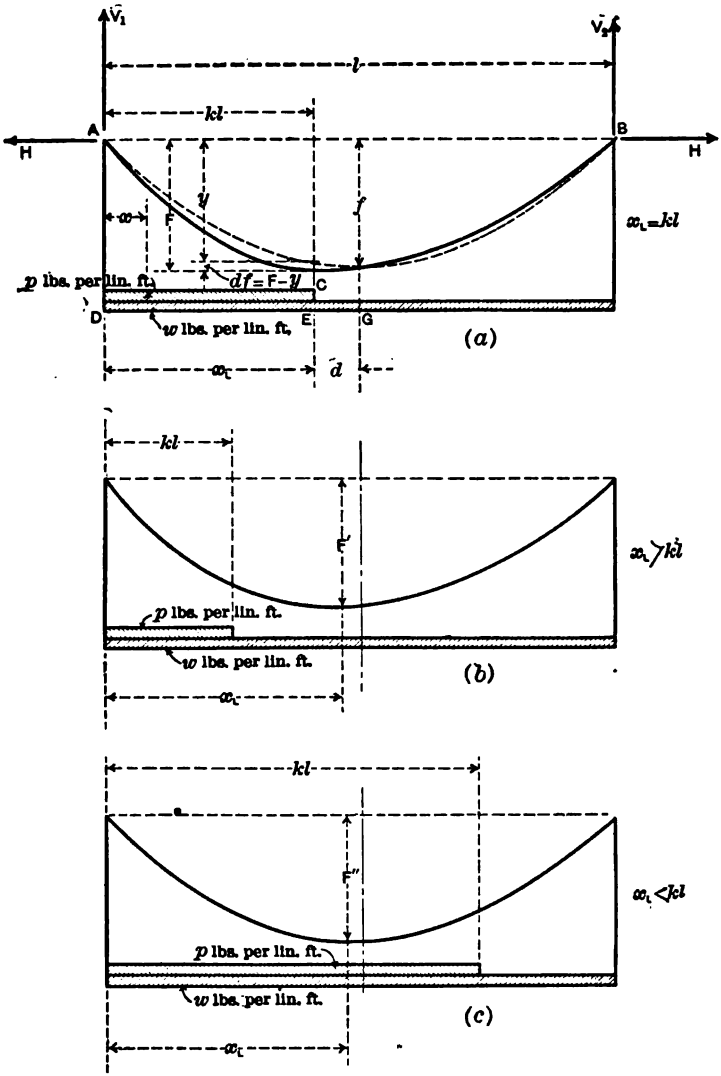
V1
V2
l
kl
A
B
H
H
x
F
y
f
x_L = kl
p lbs. per lin. ft.
df = F − y
C
D
E
G
w lbs. per lin. ft.
(a)
x_L
d
kl
F'
x_L > kl
p lbs. per lin. ft.
w lbs. per lin. ft.
(b)
x_L
kl
F''
x_L < kl
p lbs. per lin. ft.
w lbs. per lin. ft.
(c)
x_L

FIG. 9.

From $\Sigma H = 0$

$$T = H \frac{ds}{dx}. \quad . \quad . \quad . \quad . \quad . \quad . \quad . \quad . \quad . \quad . \quad . \quad . \quad . \quad (4)$$

and from $\Sigma V = 0$

$$H \frac{dy}{dx} - V_1 + (w + p)\, x = 0; \frac{dy}{dx} = \frac{V_1 - (w + p)\, x}{H}. \quad (5)$$

From Fig. 9 (*a*)

$$V_1 = \frac{w l}{2} + \frac{p k l}{2} (2 - k)$$

Substituting this value in eq. (5) and integrating, we have

$$y = \frac{(w + p)\, [\, x\, (l - x)\,] - p l\, x\, (1 - k)^2}{2 H}. \quad . \quad . \quad . \quad (6)$$

which is the equation of the cable curve from A to C, Fig. 9 (*a*), or

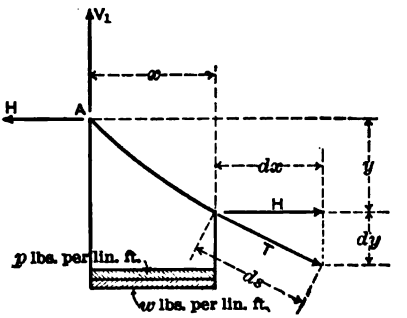

FIG. 10.

for x less than $k\,l$. In the same way, the equation of the cable curve from C to B, or for x greater than $k\,l$, is found to be

$$y = \frac{(w\,x + p\,k^2\,l)\ (l - x)}{2\,H}. \quad . \quad . \quad . \quad . \quad . \quad . \quad (7)$$

As given by eqs. (6) and (7), the equation of the curve is expressed in terms of H, the horizontal component of the cable stress. The equation will be in a form more convenient for use if stated in terms of f, the centre sag of the unloaded cable, shown by dotted lines in Fig. 9 (*a*). This may be done by placing the length of the two portions of the cable $A\,C$ and $C\,B$, Fig. 9 (*a*), as determined from eqs. (6) and (7) respectively, equal to the total length of the cable, assuming that the

cable does not change length under stress. For the determination of the length of the cable it will be sufficiently accurate to use eqs. 21 (*a*) and 25 (*a*) of Sec. I. By such substitution we obtain

$$H = \frac{l^2 w}{8f}\left[1 + \frac{2p}{w}(3 - 2k)k^2 + \frac{p^2}{w^2}k^3(4 - 3k)\right]^{\frac{1}{2}},$$

and placing this value in eqs. (6) and (7) we have, for x less than $k\,l$,

$$y = \frac{4f}{l^2}\frac{\left(\frac{p}{w} + 1\right)\left[x\,(l - x) - \frac{p}{w}l\,x\,(1 - k)^2\right]}{\left[1 + 2\frac{p}{w}(3 - 2k)k^2 + \frac{p^2}{w^2}k^3(4 - 3k)\right]^{\frac{1}{2}}} \quad . \quad (8)$$

and for x greater than $k\,l$

$$y = \frac{4f}{l^2}\frac{\left(\frac{p}{w}k^2 l + x\right)(l - x)}{\left[1 + 2\frac{p}{w}(3 - 2k)k^2 + \frac{p^2}{w^2}k^3(4 - 3k)\right]^{\frac{1}{2}}}. \quad . \quad (9)$$

From eqs. (8) and (9), it can be seen that the form of the cable depends upon the ratio of the dead and live load.

The lowest point in the curve for any loading may be found by placing equal to zero the first derivative with respect to x of eqs. (8) and (9) and solving for x. From eq. (8) we get

$$x_L = \frac{l}{2}\frac{\left[1 + \frac{p}{w}k(2 - k)\right]}{\left(1 + \frac{p}{w}\right)} \quad . \quad . \quad . \quad . \quad (10)$$

and from eq. (9),

$$x_L = \frac{l}{2}\left(1 - \frac{p}{w}k^2\right). \quad . \quad . \quad . \quad . \quad . \quad (11)$$

where x^L represents the distance from the left end of the span to the low point of the cable curve. The conditions existing are shown in Figs. 9 (*b*) and (*c*). Eq. (10) gives the value of x_L for Fig. (*c*), when $x_L < k\,l$, and eq. (11) for Fig. (*b*) when $x_L > k\,l$.

When the low point occurs at the head of the load, then $x_L = k\,l$ in either eqs. (10) or (11), and we have

$$x_L = k\,l = l\left(\sqrt{\frac{w^2}{p^2} + \frac{w}{p}} - \frac{w}{p}\right). \quad . \quad . \quad . \quad (12)$$

Since a decrease of k in (10), and an increase of k in (11) will cause the low point to shift its position farther toward the left, it can be seen that the greatest lateral shifting occurs when k is equal in both equations, or for the conditions given in eq. (12). Then eq. (12) gives the distance $D\,E$, Fig. 9 (*a*), to the position of the greatest lateral displacement of the low point of the cable. This distance measured from the span's centre is $D\,G - D\,E = d$, or

$$d = l\left[\frac{1}{2} - \left(\sqrt{\frac{w^2}{p^2} + \frac{w}{p}} - \frac{w}{p}\right)\right]. \quad . \quad . \quad . \quad (13)$$

The sag F at the low point C, Fig. 9 (*a*), may be found from eq. (8) or (9) for $x = k\,l = l\left(\sqrt{\frac{w^2}{p^2} + \frac{w}{p}} - \frac{w}{p}\right)$. The change in sag, $d\,f$, may be found by subtracting from F the ordinate to the cable at the same point as determined from eq. (11), Art. 117. The following table gives the values of x_L for various ratios of live to dead load in eq. (12); and also values of d from eq. (13), and values of $d\,f$ as explained above:

Values of $\frac{p}{w}$	$\frac{1}{3}$	$\frac{1}{2}$	1	2	3
x_L	0.333	0.366	0.414	0.449	$0.464\,l$
d	0.167	0.134	0.086	0.051	$0.036\,l$
F	0.989	0.984	0.985	1.035	$1.151\,f$
y	0.888	0.928	0.968	0.988	$0.996\,f$
$d\,f$	0.101	0.056	0.017	0.047	$0.165\,f$

The values of F' and F'', Figs. 9 (*b*) and (*c*), for various conditions of loading may be found by placing the value of x_L, as given by eqs. (10) and (11), in eqs. (8) and (9). Then we have for F', Fig. 9 (*b*), where $x > k\,l$,

$$F' = f\,\frac{\left(1 + \frac{p}{w}k^2\right)^2}{\left[1 + 2\,\frac{p}{w}k^2\,(3 - 2\,k) + \frac{p^2}{w^2}k^3\,(4 - 3\,k)\right]^{\frac{1}{2}}} \quad . \quad (14)$$

which holds for values of k from 0 to $\left(\sqrt{\frac{w^2}{p^2} + \frac{w}{p}} - \frac{w}{p}\right)$. In the

same way for the value of F'', Fig. 9 (c), where $x < k\,l$, we have

$$F'' = f \frac{\left[1 + \frac{p}{w} k\,(2 - k)\right]^2}{\left(1 + \frac{p}{w}\right)\left[1 + 2\frac{p}{w}k^2\,(3 - 2\,k) + \frac{p^2}{w^2}k^3\,(4 - 3\,k)\right]^{\frac{1}{2}}} \qquad (15)$$

which holds for values of k from $\left(\sqrt{\frac{w^2}{p^2} + \frac{w}{p}} - \frac{w}{p}\right)$ to 1. The maximum values of F' and F'' may be found by placing equal to zero the first derivation of these quantities with respect to k. For maximum F', (Fig. (b)), the value of k is given by the equation

$$3\frac{p^2}{w^2}k^4 - 5\frac{p}{w}k^3 - 12\frac{p}{w}k^2 + 3\,k\left(\frac{p}{w} - 1\right) + 1 = 0. \qquad (16)$$

The solution of this equation for various values of $\frac{p}{w}$ gives the following results:

Values of $\frac{p}{w}$	$\frac{1}{3}$	$\frac{1}{2}$	1	2	3
k	0.300	0.290	0.275	0.265	$0.250\,l$
F'	0.988	0.978	0.964	0.936	$0.911\,f$
x_L	0.485	0.479	0.462	0.430	$0.406\,l$
y	0.999	0.998	0.995	0.980	$0.965\,f$
df	0.011	0.020	0.031	0.044	$0.054\,f$

Again from eq. (15) we find in the same way that for maximum F'', (Fig. (c)), the value of k is given by the equation

$$3\frac{p^2}{w^2}k^4 + \left(5 - 2\frac{p}{w}\right)\frac{p}{w}k^3 - 3\frac{p}{w}k^2 + 3\,k - 2 = 0. \qquad (17)$$

Values of the various quantities are given in the following table:

Values of $\frac{p}{w}$	$\frac{1}{3}$	$\frac{1}{2}$	1	2	3
k	0.655	0.650	0.645	0.640	$0.630\,l$
F''	1.002	1.012	1.018	1.022	$1.024\,f$
x_L	0.486	0.479	0.468	0.457	$0.449\,l$
y	0.999	0.998	0.996	0.994	$0.992\,f$
df	0.003	0.014	0.022	0.028	$0.032\,f$

Live-load on Central Portion.—The greatest sag for the centre point of the cable will be found to occur when the centre portion of the span only is loaded as shown in Fig. (11). Proceeding as in the previous case, the equation of the cable curve for the portion $A\ D$ is found to be

$$y = \frac{w\ x\ (l - x) + p\ l\ x\ (1 - 2\ k)}{2\ H}. \quad . \quad . \quad . \quad (18)$$

For the portion $D\ E$ we have

$$y = \frac{(w + p)\ (l - x)\ x - p\ k^2\ l^2}{2\ H}. \quad . \quad . \quad . \quad . \quad (19)$$

If the centre sag at point C is F, then in eq. (19) for $y = F$ and $x = \frac{l}{2}$ we have

$$H = \frac{l^2}{8\ F}\ [(w + p) - 4\ p\ k^2]. \quad . \quad . \quad . \quad . \quad (20)$$

It is readily seen that the maximum value of H will occur when $k = 0$,

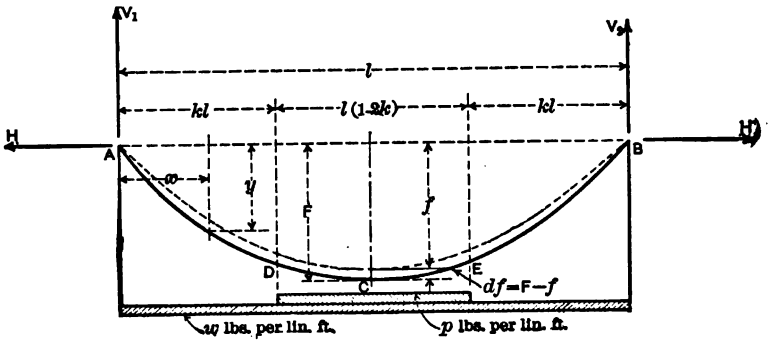

FIG. 11.

or for the entire span loaded with $(w + p)$ pounds per lin. ft. The value of H is then $(w + p)\ \frac{l^2}{8\ f}$, where F is equal to f, the centre sag of the cable under full load. Substituting the value of H from eq. (20) in eqs. (18) and (19) we have as the equations of the cable curve

For $x < k\ l$

$$y = \frac{4\ F}{l^2}\ \frac{w\ x\ (l - x) + p\ l\ x\ (1 - 2\ k)}{[(w + p) - 4\ p\ k^2]}. \quad . \quad . \quad . \quad (21)$$

And for $x > k\,l$

$$y = \frac{4\,F}{l^2}\,\frac{[(w+p)\,(l-x)\,x - p\,k^2\,l^2]}{[(w+p) - 4\,p\,k^2]}. \quad . \quad . \quad . \quad (22)$$

To determine the relation between F and f we may proceed as before to determine the lengths of the various portions of the curve from eqs. (21) and (22) and equate them to the total length of the cable.

Using the same approximate equations as before, we have, length $A\,D = E\,B =$

$$k\,l\left\{1 + \frac{8}{3}\,\frac{F^2}{l^2}\,\frac{w^2\,k^2}{[(w+p) - 4\,p\,k^2]} + \frac{8\,F^2}{l^2}\,\frac{[w\,(1-k) + p\,(1-2\,k)]^2}{[(w+p) - 4\,p\,k^2]^2}\right\}$$

also length, $D\,C\,E =$

$$l\,(1-2\,k)\left\{1 + \frac{8}{3}\,\frac{F^2}{l^2}\,\frac{[(w+p)\,(1-2\,k)]^2}{[(w+p) - 4\,p\,k^2]^2}\right\}$$

The length of the unloaded cable, with sag f, is $l\left(1 + \frac{8}{3}\,\frac{f^2}{l^2}\right)$. Placing the expression for $D\,C\,E + 2\,A\,D$ equal to total length of cable and reducing, we have

$$F = f\,\frac{\left[\left(\frac{p}{w} + 1\right) - 4\,\frac{p}{w}\,k^2\right]}{\left[\left(\frac{p}{w} + 1\right)^2 - 4\,\frac{p^2}{w^2}\,k^2\,(3 - 4\,k) - 4\,\frac{p}{w^2}\,k^2\,(3 - 2\,k)\right]^{\frac{1}{2}}}. \quad (23)$$

From eq. (23) the sag F under any partial loading may be determined in terms of the sag f of the unloaded cable. The deflection due to the given loading will be $F - f = d\,f$. By placing the first derivative of F with respect to k in eq. (23) equal to zero and solving for k, we may determine the position of loading for maximum F or $d\,f$. Thus we find the value of k to be given by the equation

$$\frac{p}{w}\left(2\,\frac{p}{w} + 1\right)k^3 - 3\,\frac{p}{w}\left(\frac{p}{w} + 1\right)k^2 + \frac{3}{4}\left(2\,\frac{p}{w} + 1\right)\left(\frac{p}{w} + 1\right)k - \frac{1}{4}\left(\frac{p}{w} + 1\right)^2 = 0. \quad . \quad (24)$$

The values of k from eq. (24) for various ratios of $\frac{p}{w}$ are given in the following table. Also values of F, determined by substituting the above values of k in eq. (23), and the resulting values of $d\,f$ are given in the same table.

Values of $\frac{P}{w}$	$\frac{1}{3}$	$\frac{1}{2}$	1	2	3
k	0.352	0.356	0.375	0.402	$0.410\,l$
F	1.022	1.028	1.045	1.066	$1.097\,f$
df	0.022	0.028	0.045	0.066	$0.097\,f$

SECTION III.—STIFFENED SUSPENSION BRIDGES

185. Introduction.—In suspension bridges which are to be used for heavy traffic, the roadway must be kept as nearly as possible at the same grade under all conditions of loading. To accomplish this, the cable must be prevented from swinging into a new equilibrium curve when the span is only partially loaded with live load. The desired resistance to distortion is usually obtained by one of the two

FIG. 12.

following methods: 1. By a horizontal stiffening truss suspended from the cable; 2. By making the cables themselves rigid enough to resist the distortion.

Fig. 12 shows a structure of the first class mentioned above. A truss carrying the roadway or track is suspended from the cable. Due

FIG. 13.

to the stiffness of the truss, a load applied at any point, or a uniform load covering a part of the structure, will be distributed to the cable approximately as a uniform load. The stiffer the truss the more nearly uniform will be the load on the cable and therefore the less the distortion of the cable.

In the Brooklyn Bridge, which is of this type, inclined stays were added, which ran out to about the quarter-point of the span as shown in Fig. 13. Due to the uncertainty of just how these stays act under loading, and also because they have not been found to act efficiently as a means of stiffening the roadway, their use has been abandoned.

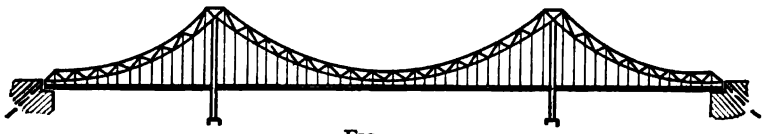

FIG. 14.

In structures of the second class, the cable itself is made rigid. This may be done in several different ways. One arrangement is shown in Fig. 14. Two eye-bar chains are hung one above the other and braced to form a rigid system which is similar in nature to a hinge-

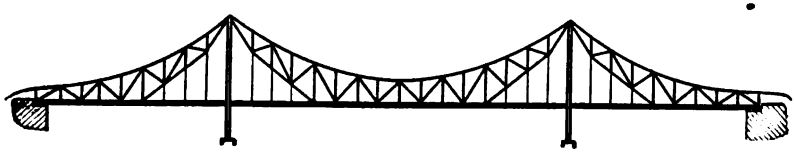

FIG. 15.

less arch. Due to difficulties in erection and uncertainty of stress calculation, examples of this system are rare.

The structure shown in Fig. 15 is similar to a two-hinged arch, inverted. This form was used in one of the proposed designs for the Manhattan Suspension Bridge in New York City.

FIG. 16.

In Fig. 16 is shown a structure built on the three-hinge-arch principle. The Point Suspension Bridge at Pittsburg is a notable example of this type. Here the stresses are all statically determinate, and are,

therefore, not subject to any of the uncertainties which exist in the types shown in Figs. 14 and 15.

In the following articles the structures here shown will be taken up in detail and methods for stress calculation developed. This work will be divided into two parts—one part referring to structures in which a horizontal stiffening truss is used, the other to structures in which the cable itself is made rigid. The treatment, however, will refer mainly to structures with horizontal stiffening trusses. In the case of structures with stiffened cables the methods used in arch analysis can be applied with but few modifications, which will be taken up in detail.

186. General Method of Procedure.—In the determination of stresses in structures with horizontal stiffening trusses the following assumptions are made:

1. The initial curve of the cable is parabolic.

2. The entire dead load is carried by the cable and causes no stress in the stiffening trusses. The trusses are stressed by changes of temperature, and by live load.

The first assumption is based upon the facts brought out in Section I of this chapter, concerning the cable as a structure by itself.

The second depends upon the field methods used in the erection of such structures. The trusses are erected with all joints field bolted. After the erection has been completed and the trusses brought to the desired grade by adjustment of the hangers, the joints are riveted up at the proper temperature, realizing the assumed conditions.

In developing the methods of calculation, the discussion will be divided into Approximate and Exact Methods. In the Approximate Method, the trusses are considered to be very stiff, and the loads comparatively light. Under these conditions the effect of the deformations due to stress, upon the general dimensions of the structure will be neglected. The cable is therefore assumed to retain its original parabolic form, and the hanger loads acting thereon are assumed to be uniformly distributed under all conditions of loading. This method is sufficiently accurate for most cases.

For structures in which the trusses are not very stiff and the span long, the deformations of truss and cable can no longer be

neglected. These conditions are considered in the exact method of calculation.

(A) APPROXIMATE METHODS OF CALCULATION

187. General Expressions for Horizontal Component of Cable Stress and for Moments and Shears in the Stiffening Truss.—A cable over a single opening is stiffened by a truss suspended in any manner at R_1 and R_2 as shown in Fig. 17. Required the horizontal component of the cable stress.

Since the stiffening truss, acting alone, is capable of supporting loads, the truss and cable constitute a redundant system. The cable may be conveniently regarded as the redundant member. The same

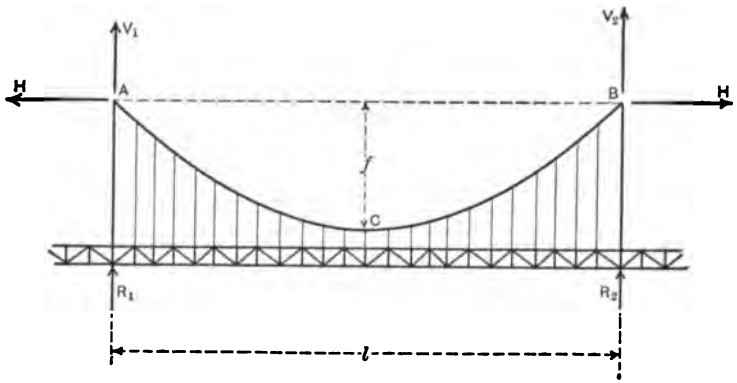

FIG. 17.

general method of analysis may be employed as explained in Part I. In proceeding with this method we will imagine the cable cut at a point near the tower. This being done the stresses in all members will be determinate, and will correspond to the stresses S' and the moments M' of Art. 222, Part I. These stresses in the towers, hangers, and cable will be zero, and the moments in the truss will be the same as if the cable was removed. Let H be the horizontal component of the cable stress and let this be taken as the redundant stress. Then from the theory of redundant members, as given in Part I, we have

for a system made up of members, part of which are acted upon by bending moments, and part by direct, or axial, stresses,

$$S_r = H = -\frac{\Sigma S' \frac{u\,l}{A\,E} + \int_0^l \frac{M'\,m}{E\,I}\,dx}{\Sigma \frac{u^2\,l}{A\,E} + \int_0^l \frac{m^2}{E\,I}\,dx}. \quad . \quad . \quad . \quad (1)$$

Where u is the direct stress in the hangers, the towers, and at any point in the cable, for a stress in the redundant member such that its horizontal component is 1 lb.; m is the bending moment at any point in the stiffening truss at the same time. The moment of inertia of the stiffening truss, I, and the area of the cable, A, are considered as uniform over their entire length.

Eq. (1) is then a general expression for the horizontal component of cable stress for structures with horizontal stiffening trusses of any form. By calculating the values of M', m, and u, subject to the conditions governing these values for the structure in question, and substituting in eq. (1), an expression for the horizontal component of the cable stress can be obtained for any particular case.

The moment at any point in the stiffening truss after the addition of the cable will be given by the equation

$$M = M' + H\,m. \quad . \quad . \quad . \quad . \quad . \quad . \quad . \quad (2)$$

This equation is obtained in the same manner as the expression for stress in any member of a system with a redundant member.

The shear at the same point is

$$V = \frac{d\,M}{d\,x} = \frac{d\,M'}{d\,x} + H\,\frac{d\,m}{d\,x} = V' + H\,\frac{d\,m}{d\,x}. \quad . \quad . \quad . \quad (3)$$

where V' is the shear in the truss before the addition of the cable.

These general expressions will now be applied to particular cases, and values of horizontal component of cable stress, moment, and shears will be derived.

(a) Structure over a Single Opening, Truss Hinged at the Ends

188. Value of H for Various Cases.—In the structure shown in Fig. 18, the stiffening truss is a simple beam of span l, anchored at the ends, at which points it is free to turn. Required the stresses in the

various parts of the structure due to any loading. The horizontal component of the cable stress is given by eq. (1), when M', m, and u are determined for the conditions shown in Fig. 18.

The value of M' depends upon the loading in question and is to be calculated as for a simple beam of span l.

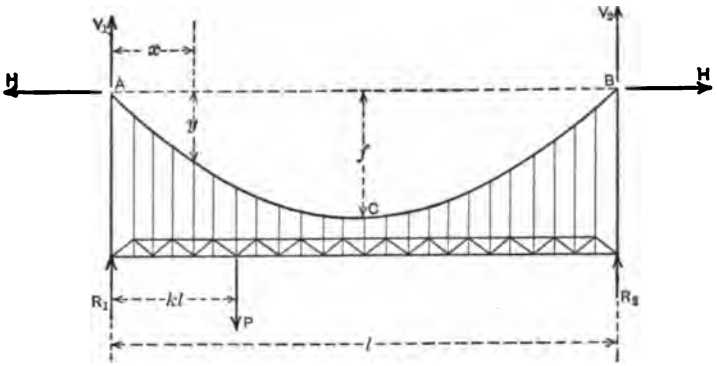

FIG. 18.

The value of m, the bending moment at any point in the stiffening truss for a 1-lb. load at A, acting horizontally, is found by taking moments about the neutral axis of the truss. Fig. 19 shows a portion

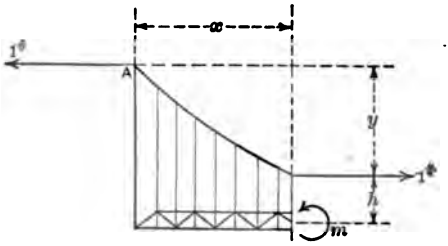

FIG. 19.

of the structure removed with all forces acting, from which we find

$$m = -(h + y) + h = -y. \quad . \quad . \quad . \quad . \quad (4)$$

The same result is obtained by the following method. The 1-lb. load at A will cause an upward pull on the truss through the hangers. Since the cable is assumed to hang in a parabola this pull will be uniform over the whole truss. Its amount will be such as to make

H equal to one pound. From eq. (26) of Section 1, we find that this load must be $\frac{8f}{l^2}$ pounds per foot. The bending moment at any point in a simple beam due to an upward load of $\frac{8f}{l^2}$ lbs. per foot, is $-\frac{4fx}{l^2}(l-x)$. Then we have as before

$$m = -\frac{4fx}{l^2}(l-x) = -y \quad . \quad . \quad . \quad (4a)$$

Also from the equilibrium polygon as drawn for a load of $-\frac{8f}{l^2}$ lbs. per ft., we have in general, $M = -Hy$, as given in Chapter II, Part I. As H is here taken as 1 lb., we have: $m = -y$.

Substituting the values determined above in eq. (1), we have

$$\int_0^l \frac{M'm}{EI}\,dx = -\frac{1}{EI}\int_0^l M'y\,dx. \quad . \quad . \quad . \quad (5)$$

Also

$$\int_0^l \frac{m^2}{EI} = \frac{1}{EI}\int_0^l y^2\,dx = \frac{16f^2}{l^4EI}\int_0^l x^2(l-x)^2\,dx = \frac{8}{15}\frac{f^2l}{EI}. \quad (6)$$

The term $\Sigma\frac{u^2l}{AE}$ of eq. (1), must be evaluated for the cable, the hangers, and the towers. It is usual, however, to neglect the parts due to the stresses in the towers and the hangers, as these terms are very small in any case.

For the cable, the value of u for a 1-lb. load at A, Fig. 18, can be seen from Fig. 20 to be $\frac{ds}{dx}$. The element of length l here becomes ds, the total length of the cable from tower to tower being L. Also, A is the area of the cable and E the coefficient of elasticity. Then, for the cable, we have

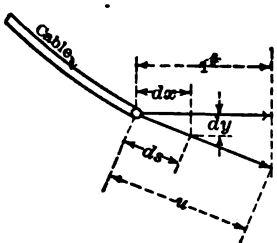

FIG. 20.

$$\Sigma\frac{u^2l}{AE} = \frac{1}{AE}\int_0^L \frac{ds^2}{dx^2}\,ds = \frac{1}{AE}\int_0^L \frac{ds^3}{dx^2}.$$

From the equation of the parabola, origin at the centre,

$$ds = \left[1 + \frac{64\, f^2 x^2}{l^4}\right]^{\frac{1}{2}} dx.$$

Substituting this value in the above expression, we have

$$\int_0^L \frac{d\,s^2}{d\,x^2} = 2\int_0^{\frac{l}{2}} \left[1 + \frac{64\, f^2 x^2}{l^4}\right]^{\frac{1}{2}} dx$$

$$= l\left\{\frac{1}{4}\left(\frac{5}{2} + \frac{16 f^2}{l^2}\right)\left(1 + \frac{16 f^2}{l^2}\right)^{\frac{1}{2}} + \frac{3}{32}\,\frac{l}{f}\log_e\left[\frac{4f}{l} + \left(1 + \frac{16 f^2}{l^2}\right)^{\frac{1}{2}}\right]\right\} \quad (7)$$

For brevity, this integral will hereafter be referred to as L_s, eq. (7).

For the hangers, the value of u is equal to the upward pull of the cable on the truss for a 1-lb. load at A, which has already been found to be $-\frac{8f}{l^2}$ lbs. per ft. The length of hanger at any point is seen from Fig. 21 to be

$$F_x = f + F_c - y = F_c + f\left[1 - \frac{4x}{l^2}(l - x)\right]$$

where F_x = length of hanger at any point and F_c = length of the centre hanger. The area of the hangers will be taken as A_h per foot

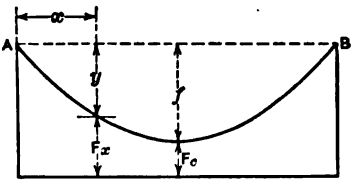

FIG. 21.

of length and E_h will be taken as the coefficient of elasticity of the hanger ropes.

Then for the hangers

$$\Sigma \frac{u^2 l}{A E} = \int_0^l \frac{64 f^2}{l^4}\,\frac{F_x}{A_h E_h} = \frac{64 f^2}{l^4 A_h E_h}\int_0^l \left\{F_c + f\left[1 - \frac{4x}{l^2}(l - x)\right]\right\} dx$$

$$= \frac{64 f^2}{l^3 A_h E_h}\left(F_c + \frac{f}{3}\right). \quad \ldots\ldots\ldots\ldots\ldots\ldots \quad (8)$$

For the towers, the value of u is equal to the vertical component of the cable stress at point A, Fig. 18, for a 1-lb. horizontal load at the

same point, or $u = \frac{dy}{dx}$. For the parabola, origin at A, when $x = 0$ we have $\frac{dy}{dx} = \frac{4f}{l}$. Therefore $u = \frac{4f}{l}$. The length of the tower will be taken as F_T and its area A_T. Then we have for the towers

$$\Sigma \frac{u^2 l}{A E} = \frac{32 f^2}{l^2} \frac{F_T}{A_T E}. \quad . \quad . \quad . \quad . \quad . \quad . \quad (9)$$

Collecting the various terms, as given by eqs. (5) to (9) and inserting in eq. (1), remembering that for this case the term $\Sigma \frac{S' u l}{A E}$ is zero, we have

$$H = \frac{\frac{1}{E I} \int_0^l M' y \, dx}{\frac{8}{15} \frac{f^2 l}{E I} + \frac{L_s}{A E} + \frac{64 f^2}{l^3 A_h E_h} \left(F_c + \frac{f}{3}\right) + \frac{32 f^2 F_T}{l^2 A_T E}} \quad . \quad (10)$$

which is the general expression for the horizontal component of the cable stress in the structure shown in Fig. 18.

In this equation the value of M' depends upon the loading in the particular case. Therefore M' must be expressed as a function of x and the integration performed as indicated in eq. (10). For a single load P, a distance $k l$ from the left end of the span, as shown in Fig. 18, the integral must be divided into two parts, one part for x less than $k l$, the other part for x greater than $k l$. The term then becomes

$$\frac{1}{EI}\int_0^l M'y\,dx = \frac{1}{EI}\int_0^{kl}[P(1-k)\,x]\left[\frac{4fx}{l^2}(l-x)\right]dx + \frac{1}{EI}\int_{kl}^{l}[P(l-x)k]\left[\frac{4fx}{l^2}(l-x)\right]dx$$

$$= \frac{1}{3EI} Pfl^2k(k^3-2k^2+1). \quad . \quad . \quad . \quad . \quad . \quad . \quad . \quad . \quad . \quad . \quad . \quad . \quad . \quad (11)$$

Substituting this value in eq. (10), neglecting the effect of the hangers and towers, we have

$$H = \frac{\frac{1}{3} P f l^2 k (k^3 - 2k^2 + 1)}{\frac{8}{15} f^2 l + \frac{I L_s}{A}} \quad . \quad . \quad . \quad . \quad (12)$$

which is the value of the horizontal component of the cable stress for a single load P on the main span. The value of H is found to be a maximum when $k = \frac{1}{2}$, or for the load at the centre of the span.

For a uniform load of p pounds per linear foot extending a distance

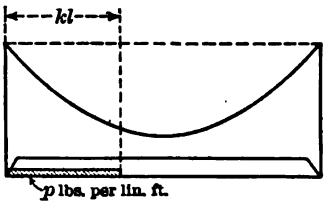

FIG. 22.

$k\,l$ from the left end as shown in Fig. 22, the term $\int M' y\,dx$ becomes

$$\int_0^l M' y\,dx = \int_0^{kl} \left[\frac{p\,k\,l}{2}(2-k)\,x - \frac{p\,x^2}{2}\right]\left[\frac{4\,f\,x}{l^2}(l-x)\right] dx + \int_{kl}^{l} \left[\frac{p\,k^2\,l}{2}(l-x)\right]\left[\frac{4\,f\,x}{l^2}(l-x)\right] dx = \frac{1}{30}\,p\,f\,l^3\,k^2\,(2\,k^3 - 5\,k^2 + 5).$$

The same result may be obtained from eq. (11) by replacing P by $p\,l\,d\,k$ and integrating between the limits k and 0. We then have

$$\int_0^l M' y\,dx = \int_0^k \frac{1}{3}\,p\,f\,l^3\,k\,(k^3 - 2\,k^2 + 1)\,dk = \frac{1}{30}\,p\,f\,l^3\,k^2\,(2\,k^3 - 5\,k^2 + 5).$$

For this case, again neglecting the effect of hangers and towers, eq. (10) becomes

$$H = \frac{\frac{1}{30}\,p\,f\,l^3\,k^2\,(2\,k^3 - 5\,k^2 + 5)}{\frac{8}{15}\,f^2\,l + \frac{I\,L_e}{A}} \quad . \quad . \quad . \quad . \quad (13)$$

which is the value of H for a uniform load extending a distance $k\,l$ from the left end of the span. The value of H is found to be a maximum when $k = 1$, or for the entire span loaded, when

$$H = \frac{\frac{1}{15}\,p\,f\,l^3}{\text{Denominator eq. (10) or (12)}}$$

For a uniform live load p lbs. per lin. ft., covering a portion of the span as shown in Fig. 23, the value of $\int M' y \, d x$ may be found from eq. (11) as explained above. Thus we have

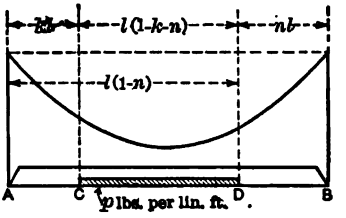

FIG. 23.

$$\int_0^l M' y \, d x = \int_k^{(1-n)} \frac{p f l^3}{3} k(k^3 - 2 k^2 + 1) \, d k$$

$$= \frac{p f l^3}{30} [2 - n^2 (5 - 5 n^2 + 2 n^3) - k^2 (5 - 5 k^2 + 2 k^3)]$$

The value of H for this case is then

$$H = \frac{\frac{1}{30} p f l^3 [2 - n^2 (5 - 5 n^2 + 2 n^3) - k^2 (5 - 5 k^2 + 2 k^3)]}{\text{Denominator eq. (12)}} \quad . \quad . \quad (14)$$

When the distances $A C$ and $D B$ are equal, or for $n = k$

$$H = \frac{\frac{1}{15} p f l^3 [1 - k^2 (5 - 5 k^2 + 2 k^3)]}{\text{Denominator eq. (12)}} \quad . \quad . \quad . \quad (15)$$

For opposite loading conditions, that is, for load on $A C$ and $D B$, Fig. 23, no load on $C D$, the value of H may be obtained by subtracting the value of H as given by eq. (14) or (15), from H for full-load conditions, or

$$H = \frac{\frac{1}{15} p f l^3 - \text{Numerator eq. (14) or (15)}}{\text{Denominator eq. (10) or (12)}}.$$

189. Effect of Temperature Changes on H.—The effect of a change of temperature on the stress in the cable is found from the term $\Sigma \frac{S' u l}{A E}$ of eq. (1). Here $\frac{S' l}{A E}$ is to be replaced by $\omega t \, d s$, the change in length of an element of the cable, $d s$, due to a change in temperature of t

degrees, the coefficient of linear expansion being denoted by ω. The value of u is again $\frac{d\,s}{d\,x}$. We then have a term of the form $\int_0^L \omega\, t \frac{d\,s^2}{d\,x}$ to be added to the numerator of the equation for H. Inserting the value of $d\,s$, and proceeding as in the derivation of L_e in eq. (7), we have

$$\int_0^L \omega\, t \frac{d\,s^2}{d\,x} = 2\int_0^{\frac{l}{2}} \left[1 + \frac{64\,f^2\,x^2}{l^4}\right] d\,x = l\left[1 + \frac{16}{3}\frac{f^2}{l^2}\right]. \quad (16)$$

Hereafter this expression will be referred to as L_t, eq. (16).

Inserting this value in eqs. (10) or (11), we have

$$H = \frac{\frac{1}{3} P\,f\,l^2\,k\,(k^3 - 2\,k^2 + 1) - E\,I\,\omega\,t\,L_t}{\text{Denominator eq. (10) or (12)}}, \quad . \quad . \quad (17)$$

which is the value of the horizontal component of the cable stress for a single load P, temperature effect included. In the same way we have for a uniform load of p pounds per foot

$$H = \frac{\frac{1}{30} p\,f\,l^3\,k^2\,(2\,k^3 - 5\,k^2 + 5) - E\,I\,\omega\,t\,L_t}{\text{Denominator eq. (10) or (12)}}. \quad . \quad (18)$$

From eqs. (17) and (18) it can be seen that a rise in temperature tends to decrease the value of the horizontal component of cable stress, while a fall in temperature causes an increase.

190. Moments and Shears.—The moment at any point in the stiffening truss can be obtained from eq. (2) by substituting for M' and m, their values for this case, M' and $-y$ respectively.

We then have

$$M = M' - H\,y \quad . \quad . \quad . \quad . \quad . \quad . \quad . \quad (19)$$

That is, the bending moment at any point in the stiffening truss is equal to the bending moment at the same point in a simple beam of like span, minus the product of the horizontal component of the cable stress and the ordinate to the cable curve at that point.

Likewise from eq. (3), the shear at any point is

$$V = V' - H\frac{d\,y}{d\,x} = V' - H\tan\theta \quad . \quad . \quad . \quad (20)$$

where V' is the shear in a simple beam of the same span, and $\tan \theta$, or $\frac{dy}{dx}$, is the slope of the cable at the point.

191. Influence Line for Moment.—The variation in the moment and shear at any point in the stiffening truss due to any condition of loading can best be studied by the use of influence lines. The influence line for moment at any point, as E, Fig. 24 (a), will now be drawn. For this purpose eq. (19) may be written

$$M = \left(\frac{M'}{y} - H\right) y. \quad . \quad . \quad . \quad . \quad . \quad (21)$$

This equation is best plotted as the difference between the two quantities $\frac{M'}{y}$ and H, as shown in Fig. 24 (b). The curved line $a\,c\,b$ shows the value of H, as calculated from eq. (12). Here P is taken as 1 pound, and the effect of temperature is neglected, as this may best be studied separately. The influence line for $\frac{M'}{y}$ is drawn in the same way as the influence line for a simple beam as explained in Part I. It is only necessary to calculate the maximum ordinate, which occurs at the point for which the influence line is to be drawn. From Fig. 24 (a) we see that for the 1-lb. load at E, $M' = n\,l\,(1 - n)$. Also at this same point y, the ordinate to the cable curve, is $4\,f\,n\,(1 - n)$. This is obtained by substituting $x = n\,l$ in the equation of the cable curve referred to point A, Fig. 24 (a), as origin. Then we have $\frac{M'}{y} = \frac{l}{4\,f}$, from which we see that the maximum ordinate is the same for all influence lines. The lines $a\,e$ and $e\,b$ give the influence line for $\frac{M'}{y}$ for point E.

In the same way, the influence line for any other point M, Fig. (a), can be drawn by locating the point m in Fig. (b) and drawing the lines $a\,m$ and $b\,m$. The same curve for H can be used for all cases.

192. Moments from Influence Lines.—The moment at point E for a load at point G will be given by the ordinate to this influence line at G multiplied by y, the cable ordinate at E, or

$$M_E = (\text{ordinate } f\,g) \times y. \quad . \quad . \quad . \quad . \quad . \quad (22)$$

From the influence line it can be seen that this moment is positive for loads on the section $D\,K$, for here the value of $\frac{M'}{y}$ exceeds H. For the section $K\,F$ the moment will be negative.

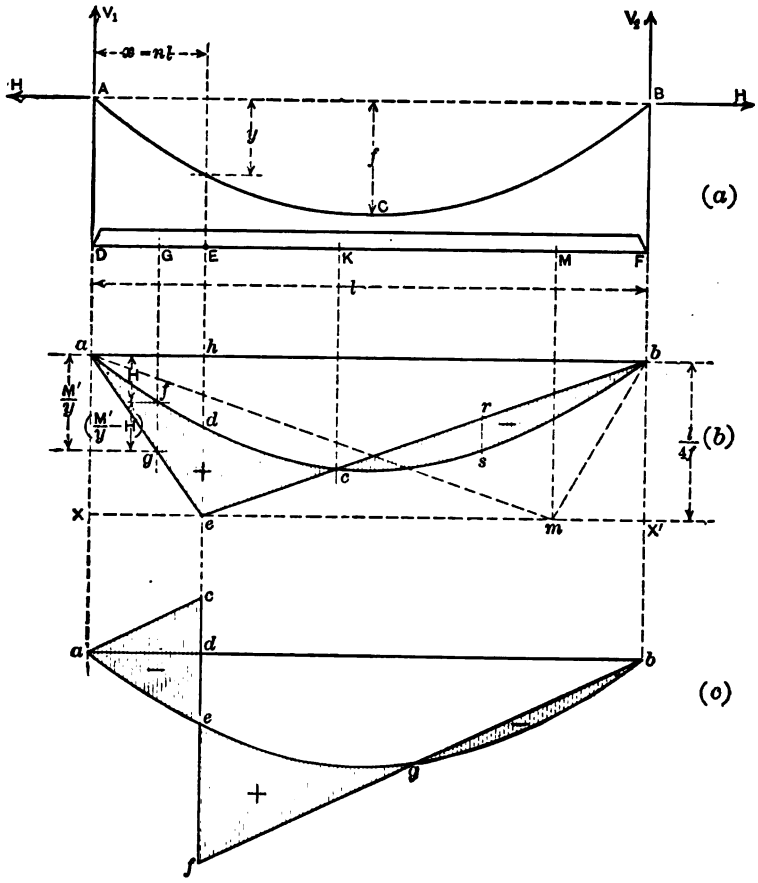

FIG. 24.

The maximum positive moment will occur when the load is at point E. For the load at point K the moment at E will be zero. The maximum negative moment at E will occur when the ordinate $r\,s$ is

greatest. The load is then at a point about half way between K and F, the exact position being best determined by trial.

The moment due to a uniform load of p lbs. per ft., extending over any portion of the span, is given by the product of the corresponding area of the influence diagram (shown by the shaded area) and the ordinate y of the given point. Or, in general,

$$M_E = p \times (\text{area influence diagram}) \times y. \quad . \quad . \quad (23)$$

For the maximum positive moment at E, the uniform load would extend from the left end of the span to point K, or

$$M_E = p \times [\text{area } a\,d\,c\,e, \text{Fig. 24 } (b)] \times y. \quad . \quad . \quad (24)$$

In the same way, the maximum negative moment occurs when the load extends from K to F, and its value is

$$M_E = p \times [\text{area } b\,r\,c\,s, \text{Fig. 24 } (b)] \times y. \quad . \quad . \quad (25)$$

193. Effect of Temperature on Moments.—The effect of changes in temperature on the moment at any point will now be considered. Temperature changes affect the value of the horizontal component of the cable stress, but do not affect the value of M' in eq. (19). Then for a change in temperature we have from eq. (19), that the change in moment is

$$M_t = -H\,y. \quad . \quad . \quad . \quad . \quad . \quad . \quad (26)$$

From eq. (17) we see that for a change in temperature of $+ t$ degrees, the value of the horizontal component of cable stress is

$$H_t = -\frac{E\,I\,\omega\,t\,L_t}{\text{Denominator eq. (10) or (12)}}. \quad . \quad . \quad (27)$$

Then from eqs. (26) and (27), the moment due to a change in temperature is

$$M_t = \pm\frac{E\,I\,\omega\,t\,L_t\,y}{\text{Denominator eq. (10) or (12)}}. \quad . \quad . \quad (28)$$

Thus a rise in temperature causes a positive moment in the stiffening truss, and a fall in temperature causes a negative moment.

From eq. (28) we see that to obtain maximum moments for live load and temperature effect combined, positive live-load moments and temperature moments due to a rise in temperature are to be taken together. Maximum negative moments are obtained by combining temperature moments due to a fall in temperature with negative live-oad moments.

194. **Influence Lines for Shear.**—To aid in drawing influence lines for shear at any point in the stiffening truss, eq. (20) will be written in the form

$$V = (V' \cot \theta - H) \tan \theta. \quad . \quad . \quad . \quad . \quad (29)$$

The values of tan θ, and cot θ in this expression may be determined from the equation of the cable curve referred to point A, Fig. 24 (a) as origin, or $\tan \theta = \frac{d\,y}{d\,x} = \frac{4f}{l^2}(l - 2x)$. For the influence line at point E, where $x = n\,l$, we have $\tan \theta = \frac{4f}{l}(1 - 2n)$. Eq. (29) then becomes

$$V = \left[\frac{V'\,l}{4f(1-2n)} - H\right]\frac{4f}{l}(1 - 2n). \quad . \quad . \quad (30)$$

The influence line for the expression in brackets will be drawn. Here the value of H is again determined from eq. (12) as in the case of moments.

The curve for H is shown by $a\,e\,g\,b$ of Fig. 24 (c). The value of $\frac{V'l}{4f(1-2n)}$ is obtained by the same methods as for simple beams. The ordinate $c\,d$, Fig. (c), obtained when the 1-lb. load is just to the left of point E is $c\,d = -\frac{n\,l}{4f(1-2n)}$. Since this is a negative quantity, it must be plotted so as to add to H, or upward from the base line $a\,b$. For the load just to the right of point E, we have $d\,f = +\frac{(1-n)\,l}{4f(1-2n)}$. This ordinate is positive and is to be plotted downward. The complete influence line is then as shown in Fig. (c).

195. Shears from Influence Lines.—The shear at E, Fig. 24 (a), for a load at any point is obtained by multiplying the ordinate to the influence line under the load by the quantity $\frac{4f}{l}(1 - 2n)$. It can be seen from Fig. (c) that loads on the ends of the span cause negative shears at point E, while loads on a short portion of the span just to the right of E cause positive shears.

For uniform loads, the shear at E is given in terms of the area of the influence diagram under the loaded portion of the span. The shear is given by the expression

$$V = p \times (\text{area influence diagram}) \times \frac{4f}{l}(1 - 2n). \quad . \quad (31)$$

For shear at the span centre, $\tan\theta$ in eq. (20) becomes zero. The cable then has no effect on the shear, which is now equal to the term V' alone. The maximum centre shear is therefore $\pm \frac{pl}{8}$ for all cases.

196. Effect of Temperature on Shear.—Temperature effects are found as before, a rise in temperature causing positive shears, and a fall in temperature causing negative shears. The general expression for shear due to temperature is given by eq. (28) when y is replaced by $\tan\theta$, the slope of the cable curve at the point in question.

197. Deflection of the Stiffening Truss.—The deflection of the stiffening truss may be calculated from the formula $D = \int_0^l \frac{M\,m}{E\,I}\,dx$ given in Part I. To apply this formula to the case in question, the stiffening truss may be considered as a simple beam of span l, acted upon by a moment which varies according to eq. (19); that is, $M = M' - H\,y$. The cable may be considered as removed, its effect on the moments in the truss being represented by H in the above equation. The value of m is found by applying a 1-lb. load at the point whose deflection is desired, and in the direction of the desired deflection.

Then, if η = deflection of any point, we have

$$\eta = \int_0^l \frac{M'}{E\,I}\,m\,dx - \int_0^l \frac{H}{E\,I}\,y\,m\,dx. \quad . \quad . \quad (32)$$

Let it be required to find the deflection at point D in the truss of Fig. 25 for a load P at point C. From Fig. 25 we find the following values for M' and m for any point distant z from the left end of span.

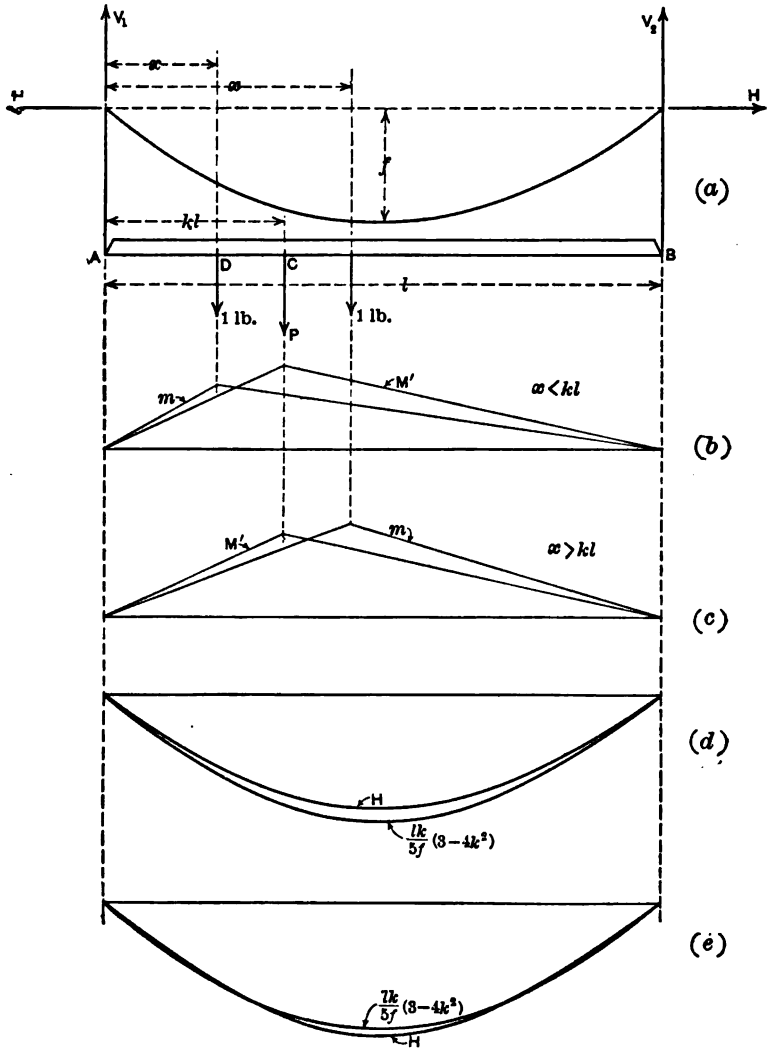

FIG. 25.

$$M'_{(A\ to\ C)} = P\ (1 - k)\ z \qquad M'_{(C\ to\ B)} = P\ k\ (l - z)$$

$$m_{(A\ to\ D)} = \frac{(l - x)\ z}{l} \qquad m_{(D\ to\ B)} = \frac{x\ (l - z)}{l}$$

Here x and $k\,l$ are constants, representing the distance from the left end of the span to the 1-lb. load and to P respectively. Figs. 25 (b) and (c) show the values of M' and m as given in the above equations. Substituting these values in eq. (32), we have for $x < k\,l$

$$\eta = \int_0^x \left[\frac{P\ (1 - k)\ z}{E\,I}\right]\left[\frac{(l - x)\ z}{l}\right] dz + \int_x^{k\,l} \left[\frac{P(1-k)\ z}{E\,I}\right]\left[\frac{x(l-z)}{l}\right] dz$$

$$+ \int_{k\,l}^{l} \left[\frac{P\ k\ (l-z)}{E\,I}\right]\left[\frac{x\ (l-z)}{l}\right] dz - \int_0^x \frac{H}{E\,I}\left[\frac{4fz}{l^2}(l-z)\right]\left[\frac{(l-x)\ z}{l}\right] dz$$

$$- \int_x^l \frac{H}{E\,I}\left[\frac{4fz}{l^2}(l-z)\right]\left[\frac{x\ (l-z)}{l}\right] dz.$$

Performing the integrations as indicated, we have

$$\eta = \frac{P}{6\,E\,I}\left[x^3\,(1 - k) - k\,l^2\,x\,(k^2 - 3\,k + 2)\right] - \frac{f\,H}{3\,E\,I\,l^2}\left[x^4 - 2\,l^3\,l + l^3\,x\right]. \quad (33)$$

In a similar manner we have when $x > k\,l$

$$\eta = \frac{P}{6\,E\,I}\left[-k\,x^3\,(3\,l - x) + k\,l^2\,x\,(k^2 + 2) - k^3\,l^3\right] - \frac{f\,H}{3\,E\,I\,l^2}\left[x^4 - 2\,x^3\,l + l^3\,x\right] \quad (34)$$

By considering x variable and k constant, eqs. (33) and (34) will give the equation of the elastic line of the truss.

For a uniform load of p lbs. per lin. ft., extending a distance $k\,l$ from the left end of span, the equation of the elastic curve may be found in a similar manner. For the loaded portion of the truss, where $x < k\,l$, we have

$$\eta = \frac{p}{24\,E\,I}\left[x^4 - 2\,x^3\,k\,l\,(2 - k) + k^2\,l^2\,x\,(2 - k)^2\right] - \frac{f\,H}{3\,E\,I\,l^2}\left[x^4 - 2\,x^3\,l + l^3\,x\right] \quad (35)$$

and for $x > k\,l$, or for the unloaded portion of the truss,

$$\eta = \frac{p\,k^2\,l}{24\,E\,I}\left[2\,x^3 - 6\,x^2\,l + x\,(k^2 + 4)\,l^2 - k^2\,l^3\right] - \frac{f\,H}{3\,E\,I\,l^2}\left[x^4 - 2x^3\,l + l^3\,x\right]. \quad (36)$$

For full load, $k = 1$ in eq. (35), and we have

$$\eta = \frac{1}{24\,E\,I}\ (x^4 - 2\,x^3\,l + l^3\,x)\left(p - \frac{8\,f\,H}{l^2}\right). \quad (37)$$

In eqs. (33) to (37) the value of H is to be taken for the loading in question, as given in Art. 188.

The expression $\left(p - \frac{8fH}{l^2}\right)$ shows the distribution of the live load between the cable and the stiffening truss under full load. The term $\frac{8fH}{l^2}$ is the hanger pull. Then the proportion of the load taken by the cable is $\frac{8fH}{pl^2}$ of the total, while that taken by the stiffening truss is $\frac{p - \frac{8fH}{l^2}}{p}$.

Under partial loading, the total load taken by the cable is $\left(\frac{8fH}{l^2}\right) l$. When the partial load extends a distance kl over the span, the total load on the truss is pkl. Then the proportion taken by the cable is $\frac{8fH}{pkl^2}$. For full load, or $k = 1$, the result is the same as given above.

198. Influence Lines for Deflection.—Influence lines for deflection at any point may be drawn from eqs. (33) and (34). By the law of reciprocal deflections, as stated in Part I, the deflection at a point distant x from the left end of the span can be found by placing $P = 1$ lb. in eqs. (33) and (34). Then if the load at point x is taken as 1 lb., the resulting equation gives the influence line for deflection at x.

To draw the influence line for deflection at the centre of the span, we must use eq. (34), as $x > kl$ for the centre point. Then with $x = \frac{l}{2}$ and $P = 1$ lb. in eq. (34), we have

$$\eta = \frac{l^3}{48EI}(3k - 4k^3) - \frac{5}{48}\frac{fHl^2}{EI}. \quad . \quad . \quad . \quad (38)$$

This equation gives the deflection at the centre for a load of 1 lb. at any point on the left half distant kl from the left end of span. To aid in drawing the influence line, eq. (38) will be written

$$\eta = \left[\frac{lk}{5f}(3 - 4k^2) - H\right]\frac{5}{48}\frac{fl^2}{EI}. \quad . \quad . \quad . \quad (39)$$

The curve for H may be used in this case in the same manner as for moment and shear influence lines. In Figs. 25 (*d*) and (*e*) are shown influence lines for deflection at the centre point. Fig. (*d*) shows the type of influence line found for structures with a stiffening truss in which the moment of inertia is large. The influence line shows that for greatest centre deflection the structure is to be fully loaded.

The amount of the deflection may be found from influence-line areas, as in the case of moments and shears, or it may be calculated directly from eqs. (35) or (37). Placing $x = \frac{l}{2}$ in eq. (37), we have

$$\eta = \frac{5\,l^4}{384\,EI}\left(p - \frac{8\,f\,H}{l^2}\right) \quad . \quad . \quad . \quad . \quad (40)$$

which is the centre deflection for the truss fully loaded. When the cable is removed, or for $H = 0$ in eq. (40), the deflection is the same as for the centre point of a simple beam of span l under uniform live load.

The influence line shown in Fig. (*e*) is the type found for structures in which the stiffening truss is very flexible. Here the greatest downward deflection is caused by loading only the centre portion of the span. Loads on the ends of the span cause upward deflections at the centre. The amounts of these deflections may be found by influence line areas as in previous cases.

199. Effect of Temperature on Deflection.—The deflection resulting from temperature changes is found from eq. (33) by placing $P = 0$ and $H = H_t$ from eq. (27).

We then have

$$\eta_t = -\frac{f\,H_t}{3\,E\,I\,l^2}\,(x^4 - 2\,x^3\,l + l^3\,x). \quad . \quad . \quad . \quad (41)$$

For the centre deflection, where $x = \frac{l}{2}$, $\eta_t = -\frac{5}{48}\frac{f\,l^2\,H_t}{EI}$.

Substituting H_t as given by eq. (27), we have

$$\eta_t = \pm \frac{\frac{5}{48}\,f\,l^2\,\omega\,t\,L_t}{\text{Denominator eq. (10) or (12)}}. \quad . \quad . \quad (42)$$

For a rise in temperature η_t is positive and the deflection is downward; for a fall in temperature η_t is negative and the deflection is upward.

(*b*) *Structure over Three Openings. Side Spans Suspended. Trusses Hinged.*

200. Value of H.—When side spans are added, which are also suspended from the cable, as shown in Fig. 26, the various terms

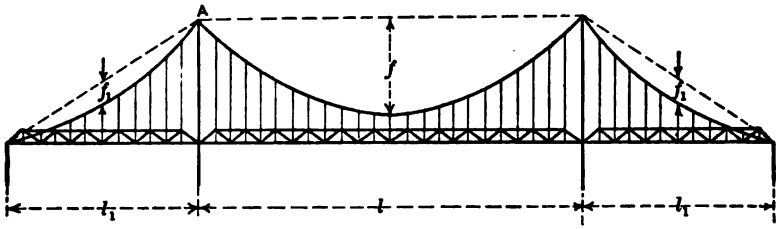

FIG. 26.

of eq. (1) must be made up to include these spans, as well as the main span.

The values of M', m, and u for the main span are the same as given in Art. 188 for the structure of Fig. 18.

The side-span values are obtained by methods similar to those used for the main span. M' is again the moment in a simple beam of the same length as the side span. This moment will be called M'_1. The value of m is found by a method similar to that of Art. 188 to be

$$m = -\frac{4 f_1 x_1}{l_1^2}(l_1 - x_1) = -y_1$$

where x_1 and y_1 are referred to axes as shown in Fig. 2. Then we have

$$\left.\begin{aligned} \int_0^l \frac{M' m}{E I} &= -\frac{1}{E I_1}\int_0^{l_1} M'_1 y_1 \, dx \\ \text{also} \qquad \int_0^l \frac{m^2}{E I}\, dx &= \frac{16 f_1^2}{l_1^4 E I_1}\int_0^{l_1} (l_1 - x_1)^2 \, dx = \frac{8}{15}\frac{f_1^2 l}{E I_1}. \end{aligned}\right\} \quad (43)$$

These quantities are seen to be of the same form as the corresponding main-span term, the primes indicating that side-span dimensions are used.

The term $\Sigma \dfrac{u^2 l}{A E}$ is again to be made up for the cable, hangers,

and towers. The main-span terms are the same as in Art. 188. For the side spans, the value of u for the cable is $\frac{d s_1}{d x_1}$.

Then we have

$$\Sigma \frac{u^2 l}{A E} = \int_0^{L_1} \frac{1}{A E} \frac{d s_1^3}{d x_1^2}.$$

To perform this integration, it is best to apply the method used in the determination of the exact length of the side span cable, given in

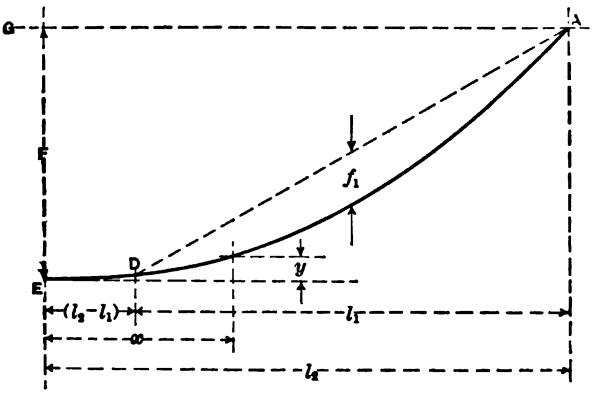

FIG. 27.

Art. 178. From the equation of the cable curve, referred to the centre point E, Fig. 27, as origin, we have

$$\frac{1}{A E} \int_0^{L_1} \frac{d s_1^3}{d x_1^3} = \frac{1}{A E} \int_{(l_2-l_1)}^{l_2} \left[1 + \frac{F^2 x_1^2}{l_2^4}\right]^{\frac{3}{2}} d x. \quad . \quad (44)$$

Then for the main span, and two side spans, we find from eq. (7), Art. 188, and eq. (44),

$$\frac{1}{A E}\left[\int_0^L \frac{d s^3}{d x^2} + 2\int_0^{L_1} \frac{d s_1^3}{d x_1^3}\right] = \frac{1}{A E}\left\{L_s \text{ eq. (7)} + 2\left[\frac{x}{8}\left(5 + 2\frac{F^2 x_1^2}{l_1^4}\right)\right.\right.$$
$$\left.\left.\left(1 + \frac{F^2 x_1^2}{l_1^4}\right)^{\frac{1}{2}} + \frac{3}{8}\frac{l_1^2}{F^2} \log_e \left[\frac{F x_1}{l_1^2}\left(1 + \frac{F^2 x_1^2}{l_1^4}\right)^{\frac{1}{2}}\right]\right]_{(l_2-l_1)}^{l_2}\right\}. \quad . \quad . \quad . \quad (45)$$

As before, this equation will be referred to as L_s eq. (45).

For the hangers, u is again equal to the upward pull of the cable on the truss, which is found to be $\frac{8 f_1}{l_1^2}$ lbs. per lin. ft. From Fig. 28 the length of a hanger at any point is

$$F_x = F_s - y_1 - x_1 \tan \alpha_1$$

where F_s is the length of the hanger at the tower, and $y_1 + x_1 \tan \alpha_1$ is the ordinate to the cable curve as given by eq. (17), Art. 175. Then

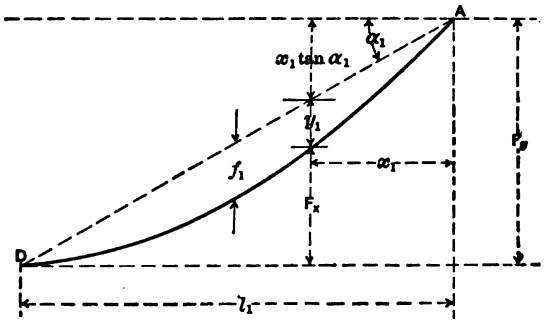

FIG. 28.

with A_h as the area of the hangers per foot of span, we have for both side spans

$$\Sigma \frac{u^2 l}{A E} = \frac{64 f_1^2}{l_1^4} \int_0^{l_1} 2 \left[F_s - \frac{4 f_1 x_1}{l_1^2} (l_1 - x_1) - x_1 \tan \alpha_1 \right] dx$$

$$= \frac{64 f_1^2}{l_1^3 A_h E_h} \left(2 F_s - \frac{4}{3} f_1 - l_1 \tan \alpha_1 \right). \quad . \quad . \quad . \quad . \quad (46)$$

From eq. (46) and from eq. (8) of Art. 188, we find for the main and side spans

$$\Sigma \frac{u^2 l}{A E} = \frac{64}{A_h E_h} \left[\frac{f^2}{l^3} \left(F_c + \frac{f}{3} \right) + \frac{f_1^2}{l_1^3} \left(2 F_s - \frac{4}{3} f_1 - l_1 \tan \alpha_1 \right) \right] \quad (47)$$

For the towers $u = \frac{d y_1}{d x_1}$, as before, which from eq. (17), Art. 175, for $x_1 = 0$, is found to be $\frac{4 f_1}{l_1} + \tan \alpha_1$. The length of the tower is F_T and the area A_T as before.

Then for both towers

$$\Sigma \frac{u^2 l}{A E} = 2 \left(\frac{4 f_1}{l_1} + \tan \alpha_1\right)^2 \frac{F_T}{A_T E}.$$

Adding this expression to that given in eq. (9), Art. 188, for the main span, we have as the total

$$\Sigma \frac{u^2 l}{A E} = \frac{F_T}{A_T E}\left[\frac{32 f^2}{l^2} + 2 \left(\frac{4 f_1}{l_1} + \tan \alpha_1\right)^2\right]. \quad . \quad (48)$$

The temperature term in the numerator will be of the form $\int_0^{L_1} \omega t \frac{d s_1^2}{d x_1}$ similar to eq. (16), Art. 189, for the main span. Proceeding as before we have from Fig. 27,

$$\int_0^{L_1} \omega t \frac{d s_1^2}{d x_1} = \omega t \int_{(l_2 - l_1)}^{l_2} \left[1 + \frac{F^2 x_1^2}{l_2^4}\right] d x$$

$$= \omega t l_1 \left[1 + \frac{(3 l_2^2 - 3 l_2 l_1 + l_1^2) F^2}{3 l_2^4}\right]. \quad . \quad . \quad . \quad (49)$$

Then for the main span and both side spans, we have from eqs. (16) and (49)

$$\Sigma \frac{S' u l}{A E} = \omega t \left\{ l \left[1 + \frac{16 f^2}{3 l^2}\right] + l_1 \left[1 + \frac{(3 l_2^2 - 3 l_2 l_1 + l_1^2) F^2}{3 l_2^4}\right]\right\} \quad (50)$$

$$= \omega t L_t \text{ eq. (50)}$$

Collecting terms and substituting in eq. (1), we have

$$H = \frac{\int_0^l M' y \, d x + \frac{I}{I_1} \int_0^{l_1} M'_1 y_1 \, d x - E I \omega t L_t \text{ eq. (50)}}{\frac{8}{15} f^2 l + \frac{16}{15} f_1^2 l_1 \frac{I}{I_1} + \frac{I}{A} L_s \text{ eq. (45)} + \frac{64 E I}{A_h E_h}\left[\frac{f^2}{l^2}\left(F_c + \frac{f}{3}\right) + \frac{f_1^2}{l_1^3}\left(2 F_s - l_1 \tan \alpha_1 - \frac{4}{3} f_1\right)\right] + \frac{F_T I}{A_T}\left[\frac{32 f^2}{l^2} + 2 \left(\frac{4 f_1}{l_1} + \tan \alpha_1\right)^2\right]} \quad . \quad (51)$$

which is the general expression for the horizontal component of cable stress for the structure shown in Fig. 26.

For any particular loading, the values of $\int_0^l M' y \, d x$ and $\int_0^{l_1} M'_1 y_1 \, d x$ are found by the methods used for the corresponding case in the preceding article.

For a single load P, a distance $k\,l$ from the left end of the main span, the value of $\int_o^l M'\,y\,d\,x$ is the same as for eq. (12), Art. 188. For a load P_1 a distance $k_1\,l_1$ from the end of one of the side spans, we have a similar expression in terms of side-span values.

Thus

$$\int_o^{l_1} M'_1\,y_1\,d\,x = \frac{1}{3} P_1 f_1 l_1^2 k_1 (k_1^3 - 2\,k_1^2 + 1).$$

Then for a single load P in the main span, neglecting the effect of the stresses in the hangers and towers, we have from eqs. (12) and (51),

$$H = \frac{\frac{1}{3} P f l^2 k (k^3 - 2\,k^2 + 1) - E\,I\,\omega\,t\,L_t \text{ eq. (50)}}{\frac{8}{15} f^2 l + \frac{16}{15}\frac{I}{I_1} f_1^2 l_1 + \frac{I}{A} L_e \text{ eq. (45)}} \quad . \quad (52)$$

For a single load P_1 in one of the side spans

$$H = \frac{1}{3}\frac{P_1 f_1 l_1^2 k_1 (k_1^3 - 2\,k_1^2 + 1) - E\,I\,\omega\,t\,L_t \text{ eq. (50)}}{\text{Denominator eq. (51) or (52)}} \quad . \quad (53)$$

For uniform load conditions, the values of $\int_o^l M'\,y\,d\,x$ and H are found in a manner similar to those of preceding articles. Thus for a uniform load of p lbs. per lin. ft., extending a distance $k\,l$ from the left end of the main span, side spans unloaded, we have from eq. (13)

$$H = \frac{\frac{1}{30} p f l^3 k^2 (2\,k^3 - 5\,k^2 + 5) - E\,I\,\omega\,t\,L_t \text{ eq. (50)}}{\text{Denominator eq. (51) or (52)}} \quad . \quad (54)$$

And for similar side-span conditions

$$H = \frac{\frac{1}{30} p f_1 l_1^3 k_1^2 (2\,k_1^3 - 5\,k_1^2 + 5)\frac{I}{I_1} - E\,I\,\omega\,t\,L_t \text{ eq. (50)}}{\text{Denominator eq. (51) or (52)}} \quad . \quad (55)$$

The horizontal component of the cable stress will be a maximum where all spans are fully loaded. Then from eqs. (54) and (55) with $k = 1$ and $k_1 = 1$.

$$H = \frac{\frac{1}{15} p f l^3 + \frac{2}{15} p_1 f_1 l_1^3 \frac{I}{I_1} + E\,I\,\omega\,t\,L_t \text{ eq. (50)}}{\text{Denominator eq. (51) or (52)}} \quad . \quad (56)$$

For the centre portion of the main span covered with a live load of p lbs. per lin. ft., that is, for conditions similar to those shown in Fig. 23, we have from eqs. (14) and (51) or (52)

$$H = \frac{\frac{1}{30}pfl^3[2 - n^2(5 - 5n^2 + 2n^3) - k^2(5 - 5k^2 + 2n^3)] - EI\omega tL_t \text{ eq. (50)}}{\text{Denominator eq. (51) or (52)}} \quad (57)$$

When the uncovered end portions of the span are equal in length, we have from eqs. (15) and (51) or (52)

$$H = \frac{\frac{1}{15}pfl^3[1 - k^2(1 - 5k^2 + 2k^3)] - EI\omega tL_t \text{ eq. (50)}}{\text{Denominator eq. (51) or (52)}}. \quad (58)$$

For opposite loading conditions—that is, the ends of the main span and both side spans, loaded, no load on the centre portion of the main span—we may write

$$H = \frac{\frac{1}{15}pfl^3 + \frac{2}{15}pf_1l_1^3\frac{I}{I_1} - \text{Numerator eq. (57) or (58)} - EI\omega tL_t \text{ eq. (50)}}{\text{Denominator eq. (51) or (52)}} \quad (59)$$

In this equation it will be best to neglect the temperature term of eqs. (57) and (58), using only the portion $\int M' y\, dx$.

201. Moments and Shears.—The moment at any point in the main span is given by the expression

$$M = M' - Hy. \quad (60)$$

This is the same as for the structure shown in Fig. 17.

For the side spans the expression for moment at any point is the same in form, but is given in terms of the corresponding side-span values; that is,

$$M = M'_1 - Hy_1. \quad (61)$$

For shears we have in the same way, for the main span

$$V = V' - H\tan\theta, \quad (62)$$

and for the side spans

$$V = V'_1 - H\tan\theta_1. \quad (63)$$

In eqs. (60) to (63) the notation is the same as already explained in Art. 190.

If in any case there is no load in a span, the moments or shears for that span are found by placing M' or V' equal zero in the above equations. The resulting moments and shears are then due to the effect of the cable stress, which may be caused by loads in other spans or by temperature changes. The values of H to be used are calculated from eqs. (52) to (59) of Art. 200.

For temperature changes the value of H_t may be obtained by placing $P = 0$ in eqs. (51) or (52).

The value of H_t is then

$$H_t = - \frac{E I \omega t L_t \text{ eq. (50)}}{\text{Denominator eq. (51) or (52)}}. \quad . \quad . \quad . \quad (64)$$

The effect of temperature on moments is given by

$$M_t = \pm H_t y = \pm \frac{E I \omega t L_t \text{ eq. (50) } y}{\text{Denominator eq. (51) or (52)}}. \quad . \quad . \quad . \quad . \quad (65)$$

As in Art. 193, a rise in temperature causes a decrease in H and an increase in M, a fall in temperature having the opposite effect.

202. Influence Lines.—The influence lines for the main span are drawn by the same methods as given in Arts. 191 and 195.

For the side spans, the expression for variation of moments and shears are of the same form as those of the corresponding main-span quantities. The values as derived in Art. 191 for the main span can then be used for side spans by substituting side-span dimensions.

The influence lines for the structure of Fig. 26 are given in Figs. 31 and 32 of Art. 205.

From the influence lines we see that for positive moments in the main span, the loading conditions are the same as for Art. 192. For side-span positive moments the side span in question is to be fully loaded, no load on the rest of the structure.

For negative moments in the main span the loading conditions are just opposite from those for positive moments; that is, the portions of the main span which were not loaded for positive moment, together with both side spans, are to be loaded for negative moments. In the side spans, the maximum negative moments occur when there is no load in the span in question, the main span and the far side span being fully loaded.

Loading conditions for shear are similar in nature. Positive main-span shears occur for the same loading conditions as described in Art. 195. Negative shears occur under opposite loading conditions. Positive side-span shears occur under partial live load in that span only, negative shears occurring under opposite loading conditions.

203. Deflection of the Stiffening Truss.—The deflection at any point in the main span truss can be found by the same method as used in Art. 197. The resulting equation will be the same in form, the value of H, however, is to be calculated for the loading in question as given by eqs. (51) to (59) of Art. 200.

For side spans, the same equations for deflection may be used, expressed in terms of side-span dimensions.

From the equations thus derived it will be found that the greatest downward deflection of points in the main span, or side spans, will occur for loads in that span only. For greatest upward deflection of the main span, both side spans are to be fully loaded, the main span to be empty, or in the case of flexible trusses, the ends only being loaded as shown by the influence line of Fig. 25. For the greatest upward deflection of a side span, the main span and the far side span are to be loaded, no load being placed in the side span in question.

Influence lines for deflection may be drawn for main and side spans by the same methods as used in Art. 198.

204. Deflection of Top of Tower or Movement of Saddle.—In structures over several openings, as shown in Fig. 26, the cable is made continuous from anchorage to anchorage. Two different methods of attachment are used at the tops of the towers. In the first, the cable rests on saddles which are free to slide, while in the second the saddles are rigidly fastened to the towers. In either case the action of moving loads on any span will tend to develop unequal horizontal components in the various parts of the cable, which must be equalized by changes in sag and span length. The point of attachment of the cables at the towers will then move until equilibrium is established. For such changes, the movable saddle slides over the top of the tower, no horizontal force acting on the tower except that due to the friction of the rollers. In the case of the fixed saddle the tower must bend, thereby inducing bending stresses in addition to those due to direct load. If the towers are made comparatively

flexible, the required motion can take place without causing heavy bending stresses.

The amount of this movement in any case can be determined by means of the formula $D = \int_0^l \frac{M\,m}{E\,I}\,dx$ as given in Part I.

To find the deflection of the point A of the structure shown in Fig. 26, we may remove the left side span, as shown in Fig. 29, and apply

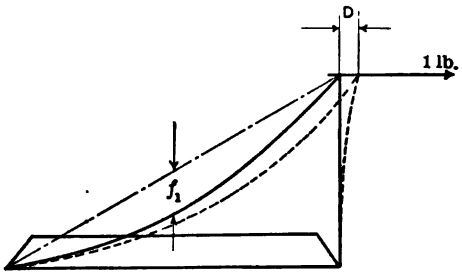

FIG. 29.

the general formula to this portion of the structure. For loads on this side span $M = M_1' - H\,y_1$ and for 1 lb. horizontal load at the top of the tower, acting as shown, $m = -\,y_1$.

Then

$$D = -\int_0^{l_1} \frac{M_1'\,y_1}{E\,I_1}\,dx + \int_0^{l_1} \frac{H\,y_1^2}{E\,I_1}\,dx$$

$$= -\int_0^{l_1} \frac{M_1'\,y_1}{E\,I_1}\,dx + \frac{8}{15}\,H\,\frac{f_1^2\,l_1}{E\,I_1}. \quad . \quad . \quad . \quad (66)$$

Here H and $\int \frac{M_1'\,y_1}{E\,I_1}\,dx$ are to be determined as in previous cases.

For no load in the side span, but for loads in the main or far side span, $\int M_1'\,y_1\,dx = 0$ and H is to be determined for the loading in question. Then eq. (66) becomes

$$D = +\frac{8}{15}\,H\,\frac{f_1^2\,l_1}{E\,I_1}. \quad . \quad . \quad . \quad . \quad . \quad (67)$$

The movement of point A due to temperature changes is found from eq. (67) by substituting H_t as found from eq. (27) of Art. 193, in place of H.

Eqs. (66) and (67) show that loads on the main and far side spans cause point A to move to the right, and that this motion is a maximum for maximum H, or for the main and far side spans completely loaded. Loads on the near side span cause point A to move to the left, and the greatest movement is caused for the side span fully loaded. For temperature changes, a rise in temperature causes point A to move to the left, and a fall causes motion to the right.

For the structure of Fig. 33, the method used above is to be applied to the main span. The resulting equations will be similar in form.

The motion of point A can also be found by means of eqs. (41) and (44) of Art. 181, which give the change in span length due to a change in sag. Then if the centre deflection, as found in Art. 203, be substituted in these equations, the results will give the corresponding motion of point A.

205. Example.—The use of the equations given in Arts. 200 to 204 will be illustrated by drawing influence lines for an actual structure and calculating values of horizontal component of cable stress, moment, and shear. The structure used for this purpose is the Manhattan Suspension Bridge in the city of New York.

a. Dimensions of Structure.—The general dimensions of the structure are shown in Fig. 30. The structure consists of four trusses, each suspended

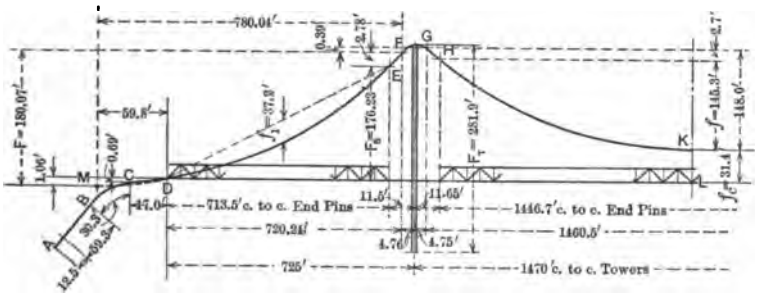

FIG. 30.

from a cable. The dimensions given are for each truss. The stiffening trusses are shown here to be horizontal, while in the actual structure they were built with a rising grade from each side toward the centre. The change was made to simplify some of the calculations relating to hanger and tower stresses.

The live load for which the structure was designed was 16,000 lbs. per foot, or 4,000 lbs. per foot per truss. In the calculations to follow these same values will be used.

b. Values of H.—As the denominator of the formula for H is the same for all conditions of loading, it may be calculated separately and used in the work to follow as a coefficient in the various equations.

From eq. (52) we have

$$\text{Denominator} = \frac{8}{15} f^2 l + \frac{16}{15} \frac{I}{I_1} f_1^2 l_1 + \frac{I}{A} L_s \text{ Eq. (50).}$$

The values to be used are given in Fig. 30. The span and cable sag to be used are for centre to centre of end pins of the stiffening trusses. These values are

l = 1,446.7 ft. f = 145.3 ft. I = 43,900 ft.^{2} × ins.^{2}
l_1 = 713.5 ft. f_1 = 37.2 ft. I_1 = 50,860 ft.^{2} × ins.^{2}
A = 275 sq. ins. per cable L_s = 3,452 ft.

The value of L_s as given is calculated from eq. (45) in the following manner: The main-span portion of this quantity is to be taken up to point G, Fig. 30, where the cable enters the saddle. From the figure, l = 1,460.5 ft. and f = 148 ft. The side-span cable lies in a parabola whose vertex is at point M, 59.8 feet beyond D, the end of the stiffening truss. From the figure l_1 = 780.04 ft. and F = 180.07 ft. These values substituted in eq. (45) give for the main span and for each side span, respectively, 1,583.3 and 805.8 feet. For the portions of the cable on the tower and anchorage saddles and the portions in the anchorage, the value of $\int \frac{d s^3}{d x^2}$ was taken as equal to the length of that portion of the cable. The totals are then

Main span	(G to K)		1,583.3
Each side span	(F to D)	805.8	
Saddle at tower	(F to G)	9.5	
Saddle at anchorage	(B to C)	30.3	
End of truss to saddle	(C to D)	17.0	
Saddle to anchorage and in anchorage	(A to B)	59.3 12.5	
		934.4	
		2	1,868.8
			3,452.1 ft.

Use L_s = 3,452 ft.

The various members of the denominator then have the following values:

$$\frac{8}{15} f^2 l = \frac{8}{15} \times 145.3^2 \times 1{,}446.7 = 16{,}290{,}000$$

$$\frac{16}{15} f_1^2 l \frac{I}{I_1} = \frac{16 \times 37.2^2 \times 713.5 \times 43{,}900}{15 \times 50{,}860} = 909{,}000$$

$$\frac{I}{A} L_s = \frac{43{,}900 \times 3{,}452}{275} = \frac{551{,}000}{17{,}750{,}000}$$

which is the value of "Denominator eq. (52)." The equations for H take the form

$$H = \frac{\int M\, y\, d\, x}{17{,}750{,}000}$$

c. Influence Lines for Moment.—The influence lines are drawn by the methods explained in Art. 202 from the equation $\left(\frac{M'}{y} - H\right) y$. The curve for H is calculated from eq. (52), which, with temperature neglected and the denominator as calculated above substituted, becomes

$$H = \frac{\frac{1}{3} P f l^2 k (k^3 - 2 k^2 + 1)}{17{,}750{,}000}.$$

Substituting main-span dimensions for f and l, and taking $P = 1$ lb.

$$H = \frac{\frac{1}{3} \times 145.3 \times 1{,}446.7^2 \times k (k^3 - 2 k^2 + 1)}{17{,}750{,}000} = 5.711\, k (k^3 - 2 k^2 + 1).$$

The curve for H for loads on the side spans is the same in form and is given by eq. (53), from which

$$H = \frac{\frac{1}{3} \times 37.2 \times 713.5^2 \times k_1 (k_1^3 - 2 k_1^2 + 1)}{17{,}750{,}000} = 0.307\, k_1 (k_1^3 - 2 k_1^2 + 1).$$

For values of k from 0 to 1, these expressions for H have the following values

k	Main Span H	Side Span H
0	0	0
0.1	0.5602	0.0301
0.2	1.0599	0.0569
0.3	1.4511	0.0780
0.4	1.6996	0.0913
0.5	1.7848	0.0959

(Symmetrical about centre of span).

These values are plotted in Fig. 31. From these curves we see that loads on the side spans have a very small effect on the cable stress.

The value of $\frac{M'}{y}$ was shown in Art. 191 to be a constant and to have a value of $\frac{l}{4f}$ for the main span. Substituting main-span values we have

$$\frac{M'}{y} = \frac{l}{4f} = \frac{1{,}446.7}{4 \times 145.3} = 2.489.$$

The corresponding side-span quantity is of the same form. Its value is

$$\frac{M_1'}{y_1} = \frac{l_1}{4 f_1} = \frac{713.5}{4 \times 37.2} = 4.795.$$

These values are plotted in Fig. 31 and influence lines drawn for moment at the quarter point and at the centre of the main and side spans.

d. Moments from Influence Lines.—The influence line shows that for maximum positive moment at the quarter point the left end of the main span is to be covered with live load, which will be taken as 4,000 lbs. per lin. ft. The area of the portion of the influence lines between the curves for H and $\frac{M'}{y}$ was calculated by dividing the area into vertical strips each $\frac{1}{20}$ of the span in length. Then by scaling these ordinates the area was easily calculated. It was found to be 375.35 units, which represents the quantity $\left(\frac{M'}{y} - H\right)$ in the general equation. The moment is then $M = 4{,}000 \times (375.35) \times 109 = 163{,}650{,}000$ ft.-lbs. In this equation the term 109 is the cable ordinate, in feet, at the quarter point, as found from the equation $y = \frac{4 f x}{l^2}(l - x)$ with $x = \frac{l}{4}$, $l = 1{,}446.7$ and $f = 145.3$. The term 4,000 is the load per foot in pounds.

The maximum negative moment at the quarter point is given by loading the right-hand portion of the main span and both of the side spans. The influence line shows that the effect of loads on the side spans is such as to cause negative moments at points in the main span, so that these spans must also be loaded to obtain maximum negative moments. The area of the main span portion of the influence line is found to be 226.7 and that of each side span 43.4. The moment is then given by the expression

$M = -4{,}000\ (226.7 + 2 \times 43.8)\ 109 = -137{,}035{,}000$ ft.-lbs.

In the same way the maximum positive moment at the centre is found to be 107,800,000 ft.-lbs., and the negative moment is found to be 76,400,000 ft.-lbs.

These moments may also be calculated directly from the equation $M' - H y$. For positive moment at the quarter point we find by scale from the influence line that the load is to extend 675 feet from the left end of the span. The value of k is then $\frac{675}{1{,}446.7} = 0.466$. Substituting this value of k in eq. (52), neglecting the effect of temperature, we have

$$H = \frac{4{,}000 \times 145.3 \times 1446.7^3 \times 0.217 \times 4.117}{30 \times 17{,}750{,}000} = 2{,}954{,}000 \text{ lbs.}$$

which is the value of H for the given loading.

The value of M', the moment at the quarter point of a simple beam of span l for a load extending a distance $k l$ from the end of the beam, is given by the equation

$$M' = \frac{p(2 - k) k l x}{2} - \frac{p x^2}{2}.$$

Substituting $k = 0.466$, $x = \frac{l}{4}$ and $l = 1{,}446.7$, we find $M' = 486{,}600{,}000$ ft.-lbs. As before $y = 109$ ft. The expression for moment is then

$$M = M' - H\,y = 486{,}600{,}000 - 2{,}954{,}000 \times 109 = 164{,}800{,}000 \text{ ft.-lbs.}$$

By comparing this value with the one calculated above from influence-line areas we see that they agree within 0.7 per cent.

The variation in moments in the main span is shown by the moment curves of Fig. 31 which are drawn for maximum positive and negative moments.

In the side spans, the influence line shows that for maximum positive moments the side span in question should be fully loaded, no load on the rest of the structure. The positive moment is then given by an expression of the form,

$$(\text{load per ft.}) \times \left[\left(\text{Area curve for } \frac{M'}{y'} \right) - (\text{area of curve for } H) \right] \times \text{ordinate to cable curve.}$$

It can be seen here that the only variable is the cable ordinate. As this follows the parabolic law, the moment also follows this law. For the centre point the moment is

$$4{,}000 \left[\frac{713.5 \times 4.795}{2} - 43.4 \right] 37.2 = + 242{,}300{,}000 \text{ ft.-lbs.}$$

For maximum negative moments the influence line shows that the main span and the far side span only are to be loaded, no load on the side span in question. Then, in the above expression, the area of the curve for $\frac{M_1'}{y_1}$ is zero. The area of the curve for H for the main span is found to be 1,649.5. The expression for centre moment is then

$$\begin{aligned} -M_c &= -\,4{,}000\ (\text{Area } H \text{ curves for main and one side span})\ y \\ &= -\,4{,}000\ (1{,}649.5 + 43.4)\ 37.2 = -\,251{,}900{,}000 \text{ ft. lbs.} \end{aligned}$$

The negative moments are seen to be a little greater than the positive moments.

e. Influence Lines for Shear.—The influence lines for shear are drawn from the equation $V = V' - H \tan\theta = (V' \cot\theta - H) \tan\theta$. From Art. 194, $\tan\theta = \frac{4f}{l}(1 - 2n)$, where nl is the distance from the left end of the span to the point for which the influence line is to be drawn. For a 1-lb. load just to the left of the point in question, the ordinate to the line for $V' \cot\theta$ is given by the expression $-\frac{nl}{4f(1-2n)}$, and for the load just to the right of the point the value is $+\frac{(1-n)}{4f(1-2n)}$.

The influence lines for shear at the end of the main span and at the quarter

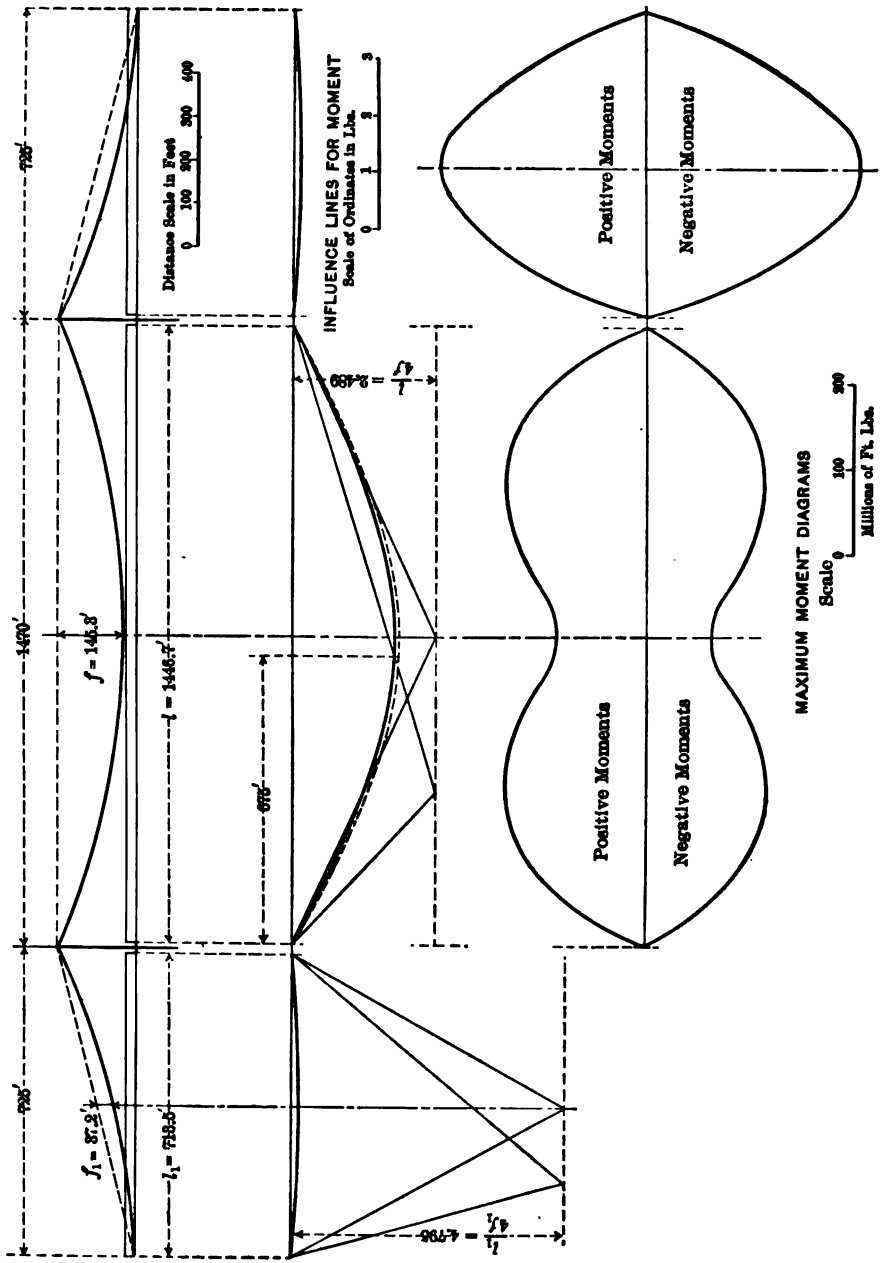
Distance Scale in Feet
0 100 200 300 400
INFLUENCE LINES FOR MOMENT
Scale of Ordinates in Lbs.
0 1 2 3
Positive Moments
Negative Moments
MAXIMUM MOMENT DIAGRAMS
Scale
0 100 200
Millions of Ft. Lbs.
Positive Moments
Negative Moments
720'
1470'
720'
f = 145.8'
l = 1446.7'
675'
f1 = 87.2'
l1 = 718.5'

FIG. 31.

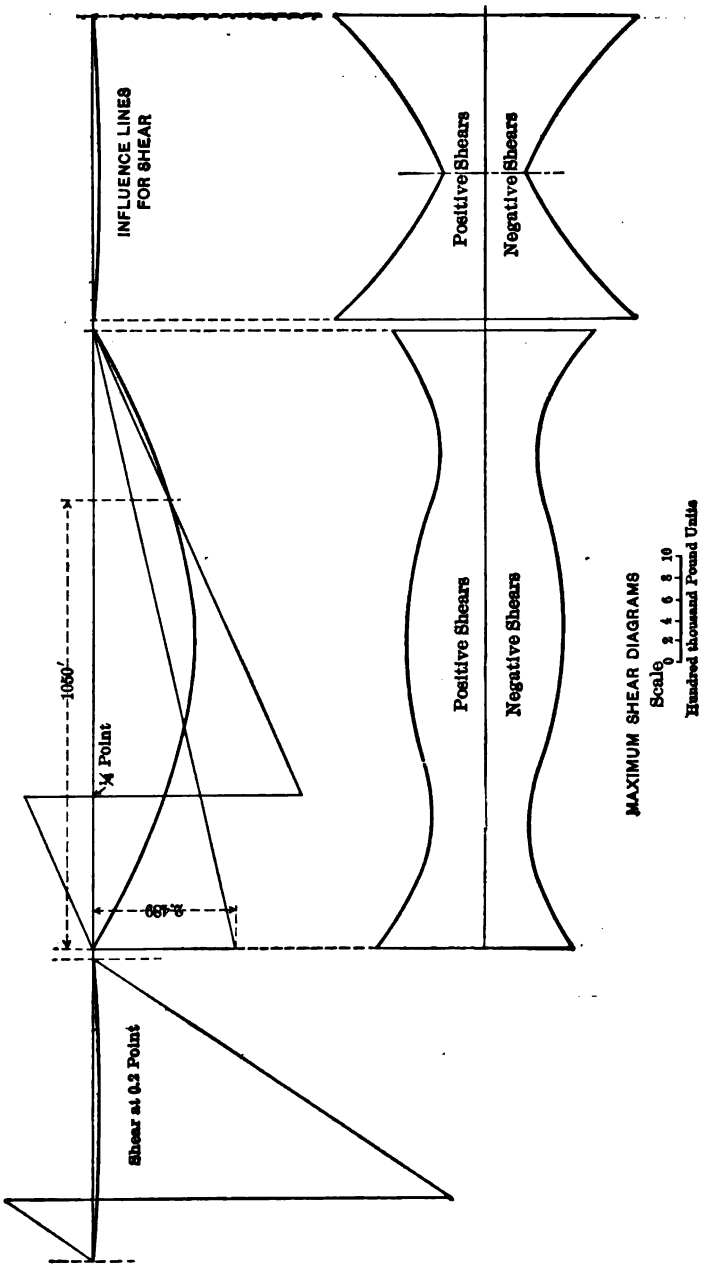
INFLUENCE LINES FOR SHEAR
Positive Shears
Negative Shears
1050'
X Point
Positive Shears
Negative Shears
MAXIMUM SHEAR DIAGRAMS
Scale
0 2 4 6 8 10
Hundred thousand Pound Units
Shear at 0.2 Point

FIG. 32.

point are shown in Fig. 32. The ordinates to the influence line at the quarter point are found from the above values to be

$$+\frac{(1-n)\,l}{4f(1-2n)} = +3.734 - \frac{n\,l}{4f(1-2n)} = -1.245.$$

f. Shears from Influence Lines.—From the influence line for shear at the quarter point the loading for maximum positive shear is found to extend from the quarter point to a point 1,050 feet from the left end of the main span. Proceeding as in the case of moments, the area between the lines for V' cot θ and H is found to be 635.2 units. The shear is then

$$+V = 4{,}000 \times 635.2 \times \tan\theta = +510{,}350 \text{ lbs.}$$

where $\tan\theta = \frac{4f}{l}(1-2n)$. Here $f = 145.3$ $l = 1446.7$ $n = \frac{1}{4}$.

The maximum negative shear at the quarter point is found for loading conditions which are opposite to those for positive shear; that is, all the structure is loaded except that part which was loaded for positive shear. The main-span influence-line area is found to be 489.36 and the area for both side spans is 86.80. The value of $\tan\theta$ is the same as before.

Then

$$-V = 4{,}000\,(489.36 + 86.80)\tan\theta = -462{,}940 \text{ lbs.}$$

For the influence line for end shear, the value of n in the expressions for ordinates as given above is zero.

Then

$$\frac{(1-n)}{4f(1-2n)} = \frac{l}{4f} = 2.489.$$

The influence line shows that for maximum positive shear, the main span is to be loaded from the left end out to a point 512.5 ft. from the end. For this loading the shear is found to be + 1,010,000 lbs.

For maximum negative shear, opposite loading conditions occur for which the shear is found to be 845,500 lbs.

The curves given in Fig. 32 show the variation in positive and negative main-span shears.

The shears for points in the side spans are determined in exactly the same way.

g. Deflection.—From eqs. (37) or (40) we find the centre deflection to be

$$\eta = \frac{5}{384}\frac{l^4}{EI}\left(p - \frac{8fH}{l^2}\right).$$

From Art. 198 the greatest downward deflection in a stiff truss occurs when the main span is fully loaded, no load on the side span. The value of H for this loading is found from eq. (54) to be 6,606,000 lbs. Then in the above equation $\frac{8fH}{l^2} = 3{,}664.5$ lbs. This quantity is the hanger pull per foot, and

therefore shows the amount of the live load which is taken up by the cable when the truss is fully loaded, the proportion being $\frac{3,664.5}{4,000} = 91.6$ per cent. The stiffening truss takes $4,000 - 3,664.5 = 335.5$ lbs. or 8.4 per cent of the live load. Substituting these values in the above equation

$$\eta = \frac{5 \times (1,446.7)^4 \times 335.5}{384 \times 29,000,000 \times 43,900} = 15.03 \text{ feet, downward.}$$

The greatest upward deflection of the centre point occurs when the side spans only are loaded, no load on the centre span. From eq. (55) the value of H is 347,300 lbs., and $\frac{8fH}{p^2} = 192.9$ lbs. per ft. In this case, p in the equation for deflection is zero, as there is no load in the main span. The deflection is found to be 8.64 ft. upward.

h. Effect of Temperature.—In the expression for temperature, the term L_t is to be calculated from eq. (50). Using the same general dimensions as for L_s we have for the various parts of the cable

Main span	2	(G to K)		1,540.5
Each side span		(F to D)	775.6	
Saddle on tower		(F to G)	9.5	
Saddle at anchorage		(B to C)	30.3	
End of truss to saddle		(C to D)	17.0	
Saddle to anchorage		(H to B)	59.3	
			891.7	
			2	1,783.4
				3,323.9 ft.

Use $L_t = 3,324$ ft.

For the portions of the cable on the saddle and towers the value of $\int \frac{ds^2}{dx}$ is taken as equal to the length of that portion of the cable. The portion of the cable in the anchorage is not considered here, as it is protected by the heavy masses of masonry and is not much affected by temperature changes.

From eq. (51) or (52) of Art. 200, neglecting the terms for loads and considering temperature effect alone, we have

$$H_t = -\frac{E\,I\,\omega\,t\,L_t \text{ eq. (50)}}{\text{Denominator eq. (52)}}$$

which gives the effect of temperature on the value of H. For $\omega = 0.0000065$ and $t = 55°$ the value of H_t is

$$H_t = \pm \frac{29,000,000 \times 43,900 \times 0.0000065 \times 55 \times 3,324}{17,750,000} = \pm 85,230 \text{ lbs.}$$

This value is negative for a rise and positive for a fall in temperature.

The effect of the change in H on the moments is given by eq. (65) of Art. 201 as

$$M_t = \pm H_t\, y = \pm 85,230 \times y.$$

For moment at the quarter-point, we have

$$M_t = \pm 85{,}230 \times 109 = \pm 9{,}290{,}000 \text{ ft.-lbs.}$$

For a rise in temperature M_t is positive.

Then the total positive moment at the quarter point, live load and temperature combined, is 163,650,000 + 9,290,000 = 172,940,000 ft.-lbs. For a fall in temperature M_t is negative and the total negative moment is − 137,035,000 − 9,290,000 = 146,325,000 ft.-lbs.

The effect of temperature on shear is given by the expression

$$V_t = \pm H_t \tan \theta.$$

For shear at the quarter point this becomes

$$V_t = + 85{,}230 \times 0.200875 = + 17{,}120 \text{ lbs.}$$

The shears then become

$$+ V_{\frac{1}{4}} = + 510{,}350 + 17{,}120 = + 527{,}470$$
$$- V_{\frac{1}{4}} = - 462{,}940 - 17{,}120 = - 480{,}060.$$

The effect of temperature on the deflection is given by eq. (42) of Art. 199 as

$$\eta_t = \frac{\frac{5}{48} f^2 \omega t L_t}{\text{Denominator eq. (52)}} = \frac{5 \times 145.3 \times (1446.7)^2 \times 0.0000065 \times 55 \times 3{,}324}{48 \times 17{,}750{,}000}$$
$$= 2.12 \text{ ft.}$$

which is downward for a rise and upward for a fall in temperature.

i. Effect of Stresses in Hangers and Towers.—In the calculations given above the effect of stresses in the hangers and towers on the values of H, M, and V has been neglected. These terms will now be calculated and their effect on moments and shears will be shown. From eq. (47) the term for the hangers is

$$\frac{64\, E I f^2}{A_h E_h l^3} \left[\left(F_c + \frac{f}{3} \right) + \frac{f_1^2}{f^2} \frac{l^3}{l_1^3} \left(2 F_s - l_1 \tan \alpha_1 - \frac{4}{3} f_1 \right) \right] = 14{,}675.$$

Here the area of the hangers per foot of length, A_h, is 0.36 sq. in.; E_h = 16,000,000 lbs. per sq. in. From Fig. 30, F_s is seen to be 176.23 ft., and F_c = 31.4 ft. The angle α_1 is measured between the line $D E$ and the horizontal; $\tan \alpha_1 = \frac{176.23}{713.5} = 0.247$.

The term for the towers is given by eq. (48) as

$$\frac{F_T}{A_T E} \left[\frac{32 f^2}{l^2} + 2 \left(\frac{4 f_1}{l_1} + \tan \alpha_1 \right)^2 \right] = 5070.$$

Here F_T is given on Fig. 30 as 281.9 ft. The area A_T is taken as the average area of the tower, which is 1,800 sq. inches. The total for these two terms is then 14,675 + 5070 = 19,745. Adding this to the "Denominator,

eq. (52)" as used above, we have 17,750,000 + 19,745 = 17,770,000 +, which is "Denominator eq. (51)."

The effect of this new denominator on H and M as calculated in paragraph (*d*) above, will now be determined. The value of H is given by

$$H = \frac{4{,}000 \times 145.3 \times (1{,}446.7)^3 \times 0.217 \times 4.117}{30 \times 17{,}770{,}000} = 2{,}949{,}000 \text{ lbs.}$$

which differs by 6,000 lbs. from that above, or 0.2 per cent. The moment now becomes

$$M = M' - H\,y = 486{,}600{,}000 - 2{,}949{,}000 \times 109 = 165{,}100{,}000 \text{ ft.-lbs.},$$

which differs from the previous value by about 0.2 per cent.

From these results it can be seen that the effect of the hanger and tower stresses can be neglected without material error.

(*c*) *Structure over Three Openings. Side Spans Free. Straight Backstays.*

206. Value of H.—In the structure shown in Fig. 33 the side spans are not attached to the cables. Loads on these spans will have

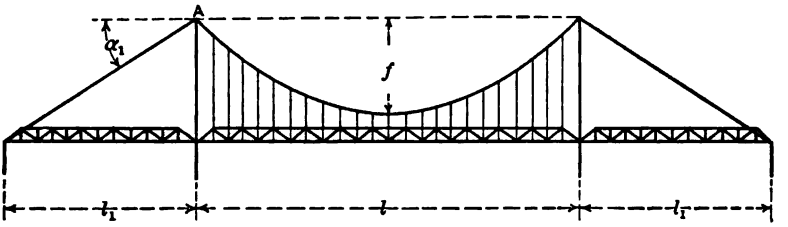

FIG. 33.

no effect on the stresses in the cable or the main-span truss. The side-span cables are straight backstays running from the tops of the towers to the anchorages.

The expression for horizontal component of cable stress will be of exactly the same form as that for the structure shown in Fig. 18, Art. 188. The values of L_s and L_l, however, will be somewhat different as the effect of the side-span cables must also be taken into account.

In the term L_s the main-span portion is the same as given by eq. (7) of Art. 188. The side-span portion is found by again sub-

stituting in the term $\Sigma \frac{u^2 l}{A E}$ of eq. (1). For a 1-lb. horizontal load at A, Fig. 33, we have

$$u = 1 \text{ lb.} \times \sec \alpha_1 = \sec \alpha_1$$

Also

$$l = d x \sec \alpha_1$$

Then we have for both side spans

$$\Sigma \frac{u^2 l}{A E} = 2 \int_0^{l_1} \frac{\sec \alpha_1{}^3}{A E} = \frac{2 l_1 \sec^3 \alpha_1}{A E}$$

The total for main and side spans then becomes

$$\Sigma \frac{u^2 l}{A E} = \frac{L_s \text{ eq. (7)}}{A E} + \frac{2 l_1 \sec^3 \alpha_1}{A E} = \frac{1}{A E} L_s \text{ eq. (68)} \quad . \quad (68)$$

In the temperature term L_t, the main-span portion is the same as given by eq. (16). The side span portion is found to be

$$\Sigma \frac{S' u l}{A E} = \frac{2}{A E} \int_0^{l_1} \omega t \sec^2 \alpha_1 \, d x = \frac{2 \omega t l_1}{A E} \sec^2 \alpha_1$$

The total for main and side spans is then

$$\Sigma \frac{S' u l}{A E} = \frac{\omega t}{A E} [L_t \text{ eq. (16)} + 2 l_1 \sec^2 \alpha_1] = \frac{\omega t}{A E} L_t \text{ eq. (69)}. \quad (69)$$

Then with these values of L_s and L_t substituted in place of the corresponding values in Art. 188, the expression for H for any particular loading conditions can be found by using the equation given for the structure of Fig. 18 for similar loading conditions.

207. Moments and Shears. Influence Lines.—The general expression for moment, shear, and deflection in the main span will be the same as given in Art. 190. As the side spans are self supporting, the stresses are determined as for simple trusses.

The influence lines for shear and moment will differ from those given in Figs. 31 and 32 only in the curve for H, which must be calculated for values of H as determined with L_s of Art. 206.

208. Example.—The same structure will be used as in Art. 205, but with straight backstays.

Values of H.—The denominator in the formula for H will again be the same for all conditions of loading. From eq. (12) of Art. 188 and eq. (68) of Art. 206 we have

$$\text{Denominator} = \frac{8}{15} f^2 l + \frac{I}{A} L_s \text{ eq. (68).}$$

As in Art. 205, $l = 1{,}446.7$ ft. $f = 145.3$ ft. $I = 43{,}900$ ins.^{2} ft^2. $A = 275$ sq. ins.

The value of L_s for the main span is the same as in Art. (205). For the side spans we find from eq. (68)

$$L_s = 2 l_1 \sec^3 \alpha_1.$$

Here $l_1 = 720.24 + 17 = 737.24$; and α_1 is the angle between a line joining points F and C of Fig. 30, Art. 205. Then

$$\sec \alpha_1 = \frac{[(737.24)^2 + (179.7)^2]^{\frac{1}{2}}}{737.24} = 1.029.$$

We therefore have for the side spans

$$L_s = 2 + 737.24 \times (1.029)^3 = 1{,}607.9.$$

The total value of L_s is found in a manner similar to that given in Art. 205 to be

Main span				1,583.3
Side spans				1,607.9
Saddle on tower	(F to G)	9.5		
Saddle at anchorage	(B to C)	30.3		
Saddle to anchorage	(A to B)	59.3		
In anchorage		12.5		
		111.6		
			2	223.2
				3,414.4

Use $L_s = 3{,}415$

In the same way, the value of L_t for this case is given by eq. (69). For the side spans $L_t = 2 l_1 \sec^2 \alpha_1 = 1{,}562.2$. The totals are then

Main span				1,540.5
Side spans				1,562.2
Saddle on tower	(F to G)	9.5		
Saddle at anchorage	(B to C)	30.3		
Saddle to anchorage	(A to B)	59.3		
		99.1		
			2	198.2
				3,300.9

Use $L_t = 3{,}300$

Substituting in the expression above we have

$$\text{Denominator} = \frac{8 \times (145.3)^2 \times 1{,}446.7}{15} + \frac{43{,}900 \times 3{,}415}{275} = 16{,}835{,}000.$$

The formula for H for a single load P in the main span is

$$H = \frac{\frac{1}{3} P f l^2 k (k^3 - 2k^2 + 1)}{16{,}835{,}000}$$

The values of H for various values of k, P being taken as 1 lb., are

$k = 0.1$	$H = 0.592$	$k = 0.3$	$H = 1.535$
$k = 0.2$	$H = 1.119$	$k = 0.4$	$H = 1.792$
	$k = 0.5$	$H = 1.882$	

(Symmetrical about span centre)

Influence Lines.—Influence lines are drawn by the same methods as used in Art. 205. The curve for H, drawn from the values given above, is shown by the dotted H line of Fig. 31.

The lines for $\frac{M'}{y}$ and $V \cot \theta$ are the same as before. These lines, together with the dotted H line then form the influence lines for this case. The side-span influence lines are not to be used in this case, as the side spans are free from the cable.

From these curves we see that the values of H are somewhat larger than those of Art. 205. The areas for moment and shear are smaller than before.

Moments from Influence Lines.—The moments at the quarter-point and centre are found to be

$+ M_{\frac{1}{4}} = + 146{,}650{,}000$	$+ M_c = + 75{,}300{,}000$
$- M_{\frac{1}{4}} = - 122{,}020{,}000$	$- M_c = - 46{,}570{,}000$

The methods used in the determination of these values are the same as given in Art. 205.

(*d*) *Structure over Three Openings. Trusses Continuous over Towers.*

209. Value of H.—In the structure shown in Fig. 34, the stiffening truss is continuous from anchorage to anchorage. At the towers,

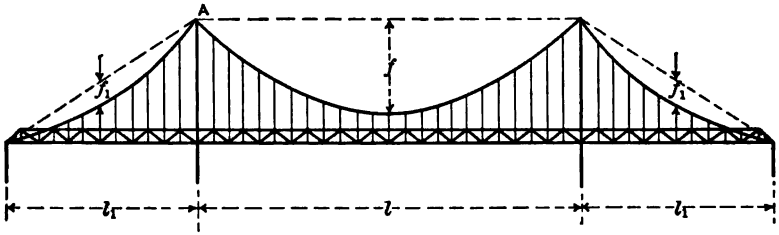

FIG. 34.

and at the ends, the truss is fastened by pins, about which it is free to turn. To determine the horizontal component of the cable stress we can

make use of eq. (1). The terms $\Sigma \frac{u^2 l}{A E}$ and $\Sigma \frac{S' u l}{A E}$ are the same as for the case given in Art. 200.

When the cable is removed the stiffening truss becomes a beam continuous over four supports. The values of M' and m must be determined subject to this condition. Fig. 35 (*a*) shows the stiffening truss with the cable removed. The length of the main and side spans, and their moments of inertia are as indicated on the figure. As the trusses are hinged at the ends, M_1 and M_4 are zero.

Let M_0 represent the moment in a simple beam.

The value of M', the moment at any point in the stiffening truss with the cable removed, is conveniently expressed in terms of M_0, M_2 and M_3. The moments M_2 and M_3 are obtained by applying the Theorem of Three Moments to the beam of Fig. 35 (*a*). For the conditions shown the formula is written in the form

$$\frac{M_1 l_1}{I_1} + 2 M_2 \left(\frac{l_1}{I_1} + \frac{l}{I}\right) + \frac{M_3 l}{I} = -\frac{P l^2}{I} 2 k - 3 k^2 + k^3) - \frac{P_1 l_1^2}{I_1} (k_1 - k_1^3)$$

By means of this equation, applied in the usual manner, we find that for a load P in the main span, no load in the side spans

$$M_2 = -\frac{P k l (1-k)\left[2 (2 - k) \frac{l_1 I}{l I_1} + 3 (1 - k)\right]}{\left(3 + 2 \frac{l_1 I}{l I_1}\right)\left(1 + \frac{2 l_1 I}{l I_1}\right)} \qquad (70)$$

$$M_3 = -\frac{P k l (1 - k)\left[2 (1 + k) \frac{l_1 I}{l I_1} + 3 k\right]}{\left(3 + 2 \frac{l_1 I}{l I_1}\right)\left(1 + \frac{2 l_1 I}{l I_1}\right)}. \qquad (71)$$

Fig. 35 (*b*) shows the variation of moments in the main and side spans in terms of M_2 and M_3 as given by eqs. (70) and (71). The heavy line in the figure shows the resulting moment M', the values for the various portions being shown on the diagram.

The value of m, the moment in the stiffening truss when the horizontal component of the cable stress is 1 lb., may be found by considering the truss as a beam continuous over four supports acted upon by

the upward pull of the hangers. In the main span this upward pull is $\frac{8f}{l^2}$ lbs. per lin. ft. found in the same way as in Art. 188. For the side spans, the upward pull is $\frac{8f_1}{l_1^2}$ lbs. per ft. It is assumed that

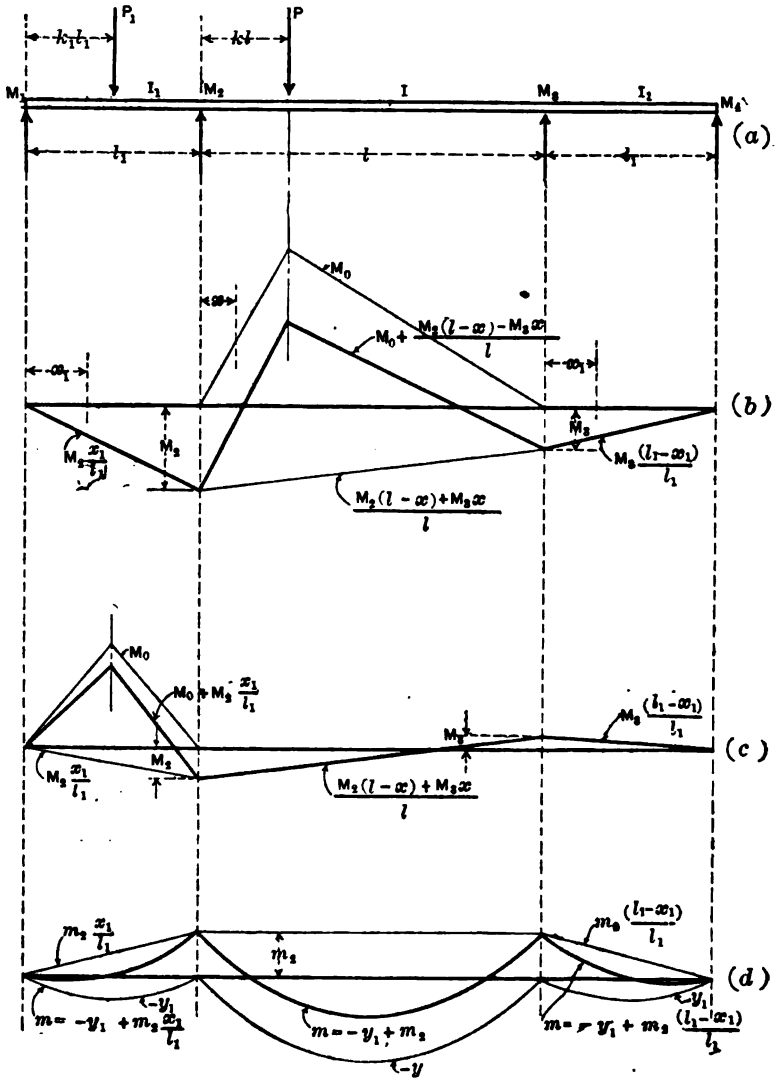

FIG. 35.

these loads are uniform across the span. Then from the Theorem of Three Moments for uniform load conditions, we find the moments at the towers, m_2 and m_3 to be

$$m_2 = m_3 = + \frac{2\left(\frac{l_1 I f_1}{l I_1 f} + 1\right) f}{\left(\frac{2 l_1 I}{l I_1} + 3\right)}. \quad . \quad . \quad . \quad (72)$$

The variation in m for other parts of the structure is as shown in Fig. 35 (d), the values being shown on the curve.

Substituting the values of M' and m as found above in eq. (1), together with $\Sigma \frac{S' u l}{A E}$, and $\Sigma \frac{u^2 l}{A E}$ for the cable, the effect of the hangers and towers being neglected, we have

$$H = \frac{\begin{array}{l} \frac{1}{EI}\int_0^l \left[M_0 + \frac{M_2(l-x)+M_3 x}{l}\right][y - m_2]dx + \frac{1}{EI_1}\int_0^{l_1}\left[\frac{M_2 x_1}{l_1}\right]\left[y_1 - \frac{m_2 x_1}{l_1}\right]dx \\ + \frac{I}{EI_1}\int_0^{l_1}\left[\frac{M_3(l_1-x_1)}{l_1}\right]\left[y_1 - \frac{m_3(l_1-x_1)}{l_1}\right]dx - \omega t L_t \text{ eq. (50)} \end{array}}{\begin{array}{l} \frac{1}{EI}\int_0^l [-y + m_2]^2 dx + \frac{1}{EI_1}\int_0^{l_1}\left[-y_1 + \frac{m_2 x_1}{l_1}\right]^2 dx + \\ \frac{1}{EI_1}\int_0^{l_1}\left[-y_1 + \frac{m_3(l_1-x_1)}{l_1}\right]^2 dx + \frac{L_s \text{ eq. (45)}}{EA} \end{array}} \quad (73)$$

Substituting the proper values of M and performing the integrations as indicated

$$H = \frac{\begin{array}{l} \frac{1}{3} P f l k(k^3 - 2k^2 + 1) - \frac{m_2}{2} P k l (1-k) + \\ \left(\frac{M_2 + M_3}{6}\right)\left[(2f - 3m_2) + 2\frac{l_1 I}{l I_1}(f_1 - m_2)\right] - \frac{EI\,\omega t L_t \text{ eq. (50)}}{l} \end{array}}{\begin{array}{l} \frac{8}{15} f^2\left(1 + \frac{2 f_1^2 l_1 I}{f^2 l I_1} - \frac{4}{3} m_2\left(1 + \frac{f_1 l_1 I}{f l I_1}\right) + m_2^2\left(1 + \frac{2}{3}\frac{l_1 I}{l I_1}\right) + \frac{I L_s}{l A} \text{ eq. (45)}\right. \end{array}} \quad . \quad . \quad . \quad (74)$$

which is the value of the horizontal component of the cable stress for a load P in the main span a distance $k\,l$ from the left end of the span. The expression $(M_2 + M_3)$, which occurs in eq. (74), is found from eqs. (70) and (71) to be

$$(M_2 + M_3) = - \frac{3 P k l (1-k)}{\left(3 + \frac{2 l_1 I}{l I_1}\right)}$$

By placing M_2, M_3 and m_2 equal to zero in eq. (74), we obtain conditions similar to the case of Art. 200. The value of H from eq. (74) becomes equal to that given by eq. (52).

For a load in one side span we find by a similar process that

$$M_2 = -\frac{\frac{2P_1 l_1^2}{l}(k_1 - k_1^3)\left(1 + \frac{l_1 I}{l I_1}\right)}{\left(3 + \frac{2 l_1 I}{l I_1}\right)\left(1 + \frac{2 l_1 I}{l I_1}\right)} \quad . \quad . \quad . \quad (75)$$

$$M_3 = +\frac{\frac{P_1 l_1^2}{l}(k_1 - k_1^3)}{\left(3 + \frac{2 l_1 I}{l I_1}\right)\left(1 + \frac{2 l_1 I}{l I_1}\right)}. \quad . \quad . \quad . \quad (76)$$

The variation of moments for this case is shown in Fig. 35 (*c*). The values of the moments for the various spans are as indicated on the figure. The values of m and m_2 and m_3 will remain the same as given in Fig. 35 (*d*) and eq. (72). Substituting in eq. (1) we have

$$H = \frac{\frac{1}{3}\frac{l_1 I}{l I_1} P_1 f_1 l_1 k_1 (k_1^3 - 2k_1^2 + 1) - \frac{m_2}{6}\frac{l_1 I}{l I_1} P_1 l_1 k_1 (1 - k_1^3) + \frac{(M_2 + M_3)}{6}\left[(2f - 3m_2) + \frac{2 l_1 I}{l I_1}(f_1 - m_2)\right] - \frac{EI\,\omega t\, L_t \text{ eq. (50)}}{l}}{\text{Denominator eq. (74)}} \quad . \quad . \quad . \quad (77)$$

which is the value of the horizontal component of the cable stress for a load P_1 in one side span at a distance $k_1 l_1$ from the left end of the span. In eq. (77) we find that $(M_2 + M_3)$ as given by eqs. (75) and (76) is

$$(M_2 + M_3) = -\frac{P_1 l_1^2 (k_1 - k_1^3)}{l\left(3 + \frac{2 l_1 I}{l I_1}\right)}$$

210. Moments and Shears.—The actual bending moment in the stiffening truss, with the cable in place, is found by substituting the values of M' and m as found above in eq. (2). For moments in the main span we have

$$M = M' + H m = M_0 + \frac{M_2 (l - x) + M_3 x}{l} - H (y - m_2). \quad (78)$$

For the moments in the side span, in which the load P_1 is located

$$M = M_0 + \frac{M_2 x_1}{l_1} - H\left(y_1 - m_2 \frac{x_1}{l_1}\right) \quad . \quad . \quad . \quad (79)$$

and for the unloaded side span

$$M = M_3 \frac{(l_1 - x_1)}{l_1} - H\left[y_1 - m_3 \frac{(l_1 - x_1)}{l_1}\right] . \quad . \quad . \quad (80)$$

The shear at any point in the main span may be found from eq. (3), or by taking the first derivative of eq. (78). In either case we have

$$V = V_0 + \frac{M_3 - M_2}{l} - H \tan \theta. \quad . \quad . \quad . \quad (81)$$

in which V_0 = shear in a simple beam.
From eqs. (70) and (71), we find

$$M_3 - M_2 = + \frac{P k l (1 - k)(1 - 2k)}{\left(1 + \frac{2 l_1 I}{l I_1}\right)}.$$

For the loaded side span

$$V = V_0 + \frac{M_2}{l_1} - H \tan \theta_1. \quad . \quad . \quad . \quad . \quad (82)$$

Here M_2 is to be taken from eq. (75).
For the unloaded side span,

$$V = - \frac{M_3}{l_1} - H \tan \theta_1. \quad . \quad . \quad . \quad . \quad . \quad (83)$$

In this case M_3 is given by eq. (76).

211. Influence Lines.—Influence lines for moments and shears may be drawn as in the previous cases.

For moments in the main span eq. (78) may be written in the form

$$M = \left[\frac{M_0 + \frac{M_2 (l - x) + M_3 x}{l}}{(y - m_2)} - H\right](y - m_2). \quad . \quad (84)$$

Then by methods similar to those used in Art. 188 the required influence line may be drawn. For an example see Art. 212.

212. Example.—The structure shown in Fig. 30 and used in the Problem of Art. 205 will be adapted to the conditions of Art. 214 and used to illustrate the calculation of influence lines and moments. For this purpose it will

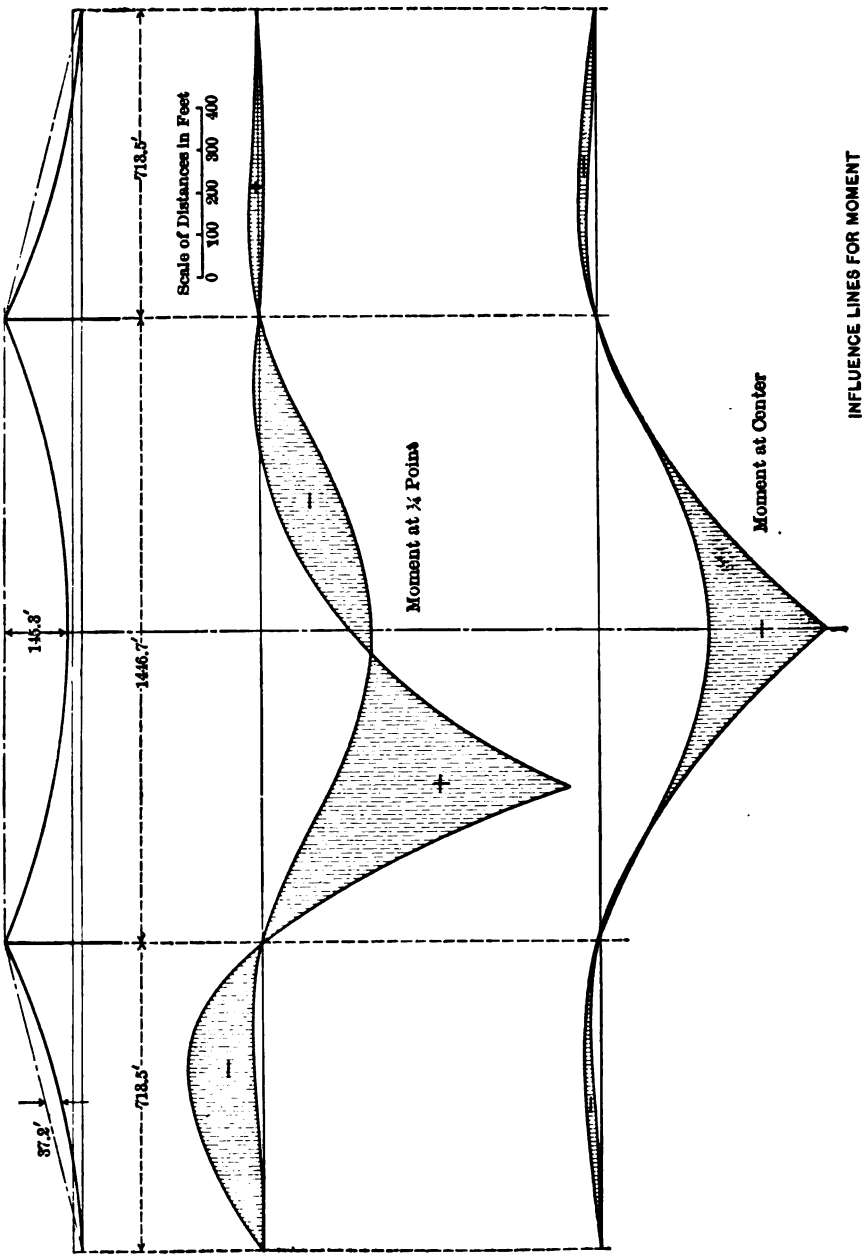
Scale of Distances in Feet
0 100 200 300 400
718.5'
146.8'
1446.7'
718.5'
87.2'
Moment at ¼ Points
Moment at Center
INFLUENCE LINES FOR MOMENT
Scale of Ordinates in lbs.
0 1 2 3 4

FIG. 36.

be assumed that the moments of inertia and span lengths are the same as before. The dimensions of the structure are then as shown in Fig. 36.

Influence Lines.—Influence lines are drawn from eq. (84) of Art. 211. The values of H to be used are given by eq. (74) of Art. 209, for the main-span portion, and eq. (77) for the side-span portions. The value of L_s in these equations may be taken the same as for the problem of Art. 205.

The values of M_2, M_3 and m_2 are given by eqs. (70), (71), (72), (75), and (76). The variation of moments is as shown in Fig. 35.

From these equations the influence lines for moment at the centre and quarter point were calculated and plotted as shown in Fig. 36.

Moments from Influence Lines.—For positive moment at the quarter point, the influence line shows that the main span and the right-hand side span are to be loaded. By the same methods as used in Art. 205 the moment is found to be + 131,000,000 ft.-lbs.

The maximum negative moment at the quarter point occurs under opposite loading conditions. The moment is found to be − 69,500,000 ft.-lbs.

At the centre the positive moment occurs for the centre portion of the span loaded, no load on the ends or the side spans. The maximum positive moment is 151,520,000 ft.-lbs. Under opposite loading conditions, the negative moment is found to be − 36,575,000 ft.-lbs.

213. Straight Backstays.—Assume the side spans free and the trusses continuous from anchorage to anchorage, as in Fig. 37.

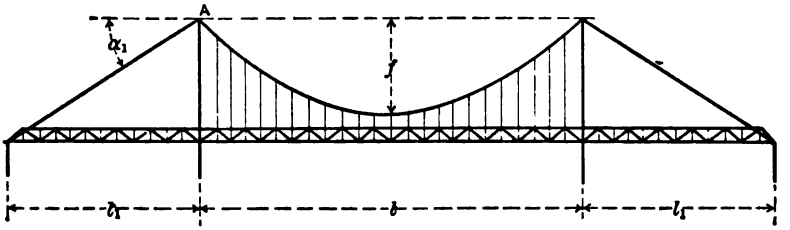

FIG. 37.

The value of M_2 and M_3 are the same as given in Art. 209. In the case of the quantity m_2 the upward pull of the side-span hangers is absent. This may be accounted for by placing f_1 in eq. (72) equal to zero and we have

$$m_2 = m_3 = \frac{2f}{\left(\frac{2l_1 I}{l I_1} + 3\right)}. \quad . \quad . \quad . \quad . \quad (85)$$

In determining the value of H for this structure it is only necessary to place $f_1 = 0$ in the corresponding equation for the structure shown in

Fig. 34. The values of L_s and L_t will be the same as those given for the structure considered in Art. 206.

(e) *Structure over Three Openings. Trusses Continuous Over Towers. Centre Hinge*

214. Value of H.—The structure shown in Fig. 34 is sometimes built with a hinge at the centre of the main span. The trusses are continuous over the main towers and the side spans are suspended

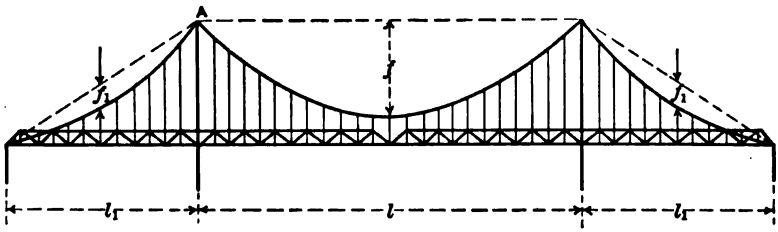

FIG. 38.

from the cables as shown in Fig. 38. The method of analysis is similar to that used for the structure of Art. 209.

When the cable is removed the stiffening truss forms a beam continuous over four supports, but hinged at the centre of the main span. For such a structure the reactions at the supports, and the moments and shears at any point, are found by the methods given for double drawbridges in Chap. II.

Fig. 39 (*a*) shows the stiffening truss with the cable removed, the dimensions of the various parts being given on the sketch. As the truss is hinged at the ends and the centre, the moments at these points are zero.

For a single load P in the main span, a distance $k\,l$ from the left end, where $k < \frac{1}{2}$, the moments at the towers are found to be

$$M_2 = -\frac{\frac{P\,k\,l}{2}\left[(2 - 3\,k + 2\,k^2) + \frac{2\,l_1\,I}{l\,I_1}\right]}{\left(1 + \frac{2\,l_1\,I}{l\,I_1}\right)} \quad . \quad . \quad . \quad (86)$$

$$M_3 = -\frac{\frac{P\,k\,l}{2}\left[(3\,k - 2\,k^2) + \frac{2\,l_1\,I}{l\,I_1}\right]}{\left(1 + \frac{2\,l_1\,I}{2\,I_1}\right)} \quad . \quad . \quad . \quad . \quad (87)$$

Fig. 39 (*b*) shows the variation of moments in the main and side spans in terms of M_2 and M_3 as given by eqs. (86) and (87). The heavy line shows the resulting moment M', the values being as indicated on the figure.

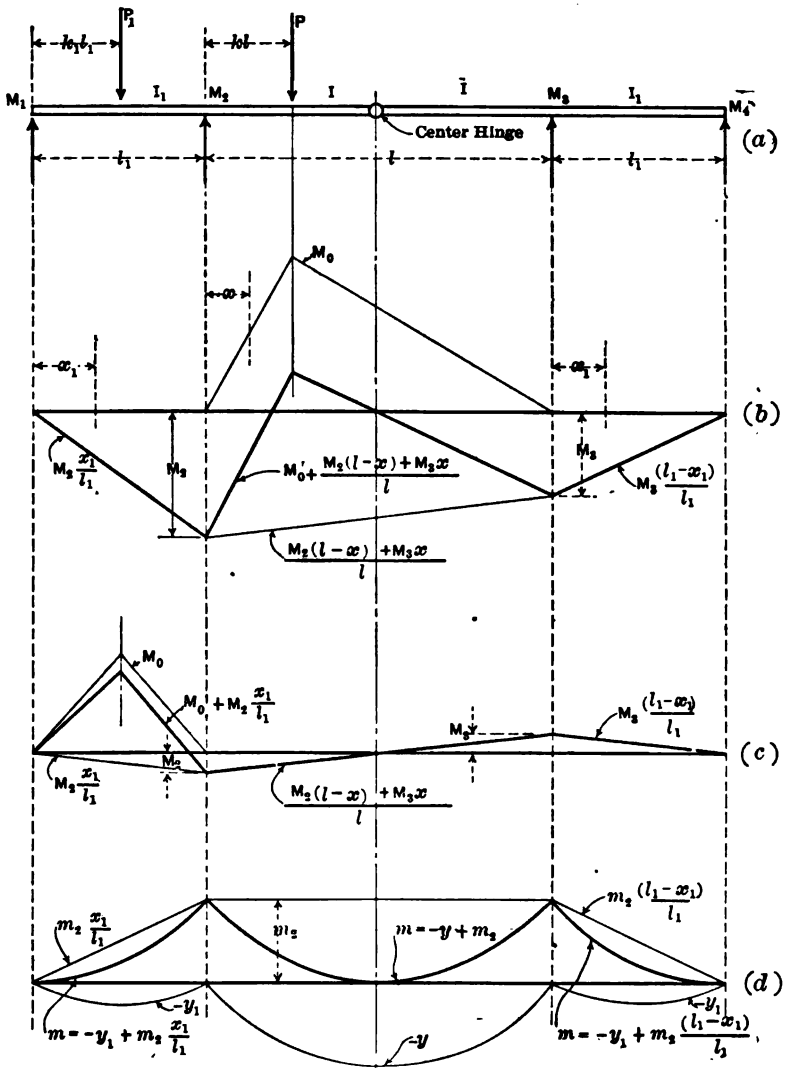

FIG. 39.

The value of m is found by a method similar to that used in Art. 209. The upward pull of the hangers on the main-span truss is again $\frac{8f}{l^2}$ lbs. per lin. ft., and for the side spans it is $\frac{8f_1}{l_1^2}$ lbs. per lin. ft. Applying these loads to the beam of Fig. 39 (*a*) the moments at the towers, m_2 and m_3 are found to be

$$m_2 = m_3 = +f \quad . \quad . \quad . \quad . \quad . \quad . \quad . \quad . \quad (88)$$

The values of m in terms of m_2 and m_3 are as shown on Fig. 39 (*d*).

By comparing the values of M' and m as given for this structure in Fig. 39 with those for the structure of Art. 209, as given in Fig. 35, we see that the expressions are similar in form, differing only in the values of M_2, M_3, m_2 and m_3. Then the expression for horizontal component of cable stress can be obtained directly from Art. 209 by substituting the values of M_2 and M_3, m_2 and m_3 for this case in place of those in eqs. (74) and (77).

From eqs. (86) and (87) we find

$$(M_2 + M_3) = -Pkl$$

Also $m_2 = m_3 = +f$. Substituting these values in eq. (74) of Art. 209, we have, after some reduction,

$$H = \frac{\frac{1}{6}Pklf\left[k(2k^2-4k+3)+2\left(1-\frac{f_1}{f}\right)\frac{l_1 I}{l I_1}\right] - \frac{EI\omega t L_t}{l} \text{ eq. (50)}}{\frac{f^2}{15}\left[3+2\left(8\frac{f_1^2}{f^2}-10\frac{f_1}{f}+5\right)\frac{l_1 I}{l I_1}\right] + \frac{I L_s}{l A} \text{ eq. (45)}} \quad (89)$$

which is the value of the horizontal component of the cable stress for a load P in the main span, a distance kl from the left end of the span for the structure of Fig. 38.

For a load in one side span, we find by a similar process that

$$M_2 = -\frac{\frac{P_1 k_1 l_1}{2}(1-k_1^2)\frac{l_1}{l}\frac{I}{I_1}}{\left(1+2\frac{l_1 I}{l I_1}\right)} \quad . \quad . \quad . \quad . \quad (90)$$

$$M_3 = -M_2. \quad . \quad . \quad . \quad . \quad . \quad . \quad . \quad . \quad . \quad (91)$$

The variation of the moment M' at any point in the beam is shown in Fig. 39 (*c*). The moment m is shown in Fig. 39 (*d*). The values of

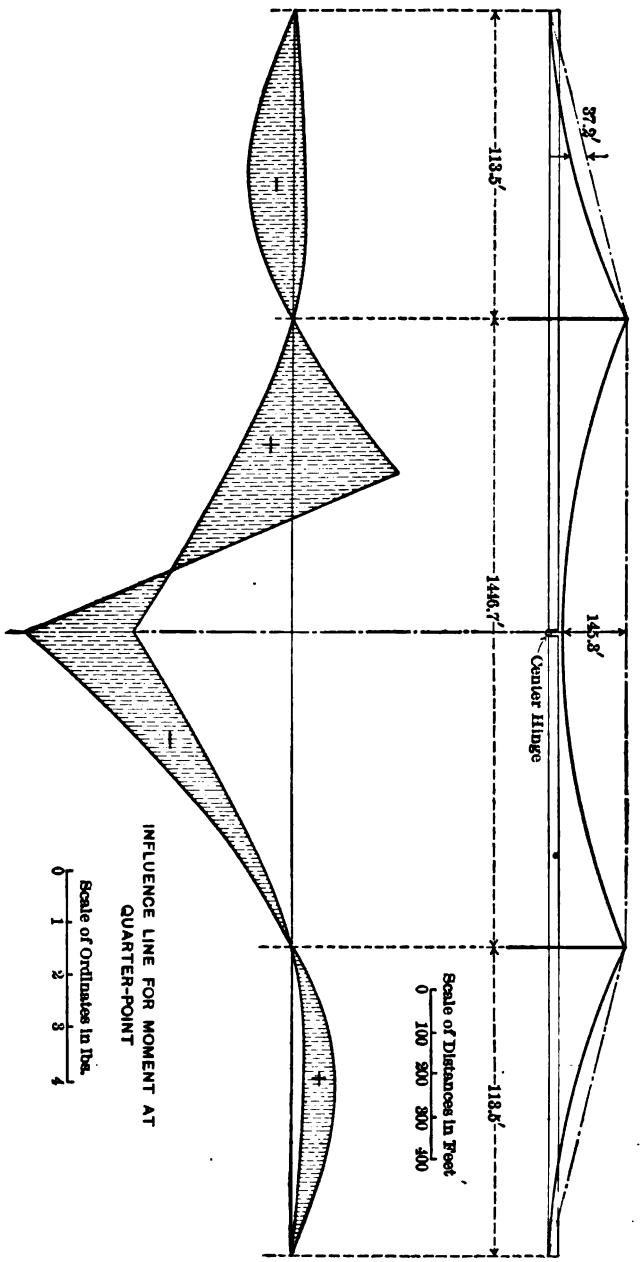
37.2′
113.5′
146.7′
145.8′
Center Hinge
118.5′
Scale of Distances in Feet
0 100 200 300 400
INFLUENCE LINE FOR MOMENT AT QUARTER-POINT
Scale of Ordinates in Ibs.
0 1/4 1/2 3/4 1

FIG. 40.

M' and m are again similar to those for the corresponding case of Art. 209. From eqs. (90) and (91) we find $(M_1 + M_2) = 0$. Substituting this value, together with the value of m_2 from eq. (88) in eq. (77) of Art. 209, we have

$$H = \frac{\frac{1}{6} P_1 f_1 l_1 \left[2 k_1 (k_1^3 - 2 k_1^2 + 1) - \frac{f}{f_1} k_1 (1 - k_1^2) \right] \frac{l_1 I}{l I_1}}{\text{Denominator eq. (89)}} \quad (92)$$

which is the expression for the horizontal component of the cable stress for a load in one side span of the structure of Fig. 38.

215. Moments and Shears.—Influence Lines.—The expressions for bending moment and shear at any point in the stiffening truss with the cable in place are of exactly the same form as those given in Art. 210 for the structure of Fig. 34. The values of H, M_2, M_3, and m_2 are, however, to be taken from eqs. (86) to (92) of Art. 214. For an example see Art. 216.

216. Example.—The same structure will be used for this case as in Art. 212, except that a centre hinge will be added in the main span. By the same methods as used in Art. 212, the influence line for moment at the quarter point of the main span was calculated and plotted in Fig. 40.

From this influence line, the maximum positive moment is found to occur when a portion of the main span and the right-hand side span are loaded. The amount of the moment is +169,150,000 ft.-lbs. For opposite loading conditions, the maximum negative moment is found to be −180,000,000 ft.-lbs.

217. Straight Backstays.—In some cases, the side spans are not attached to the cables, as shown in Fig. 41. In all other respects, the

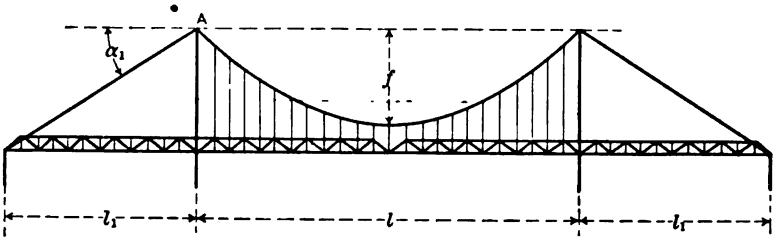

FIG. 41.

structure is similar to the one shown in Fig. 38. Values of the horizontal component of cable stress and of moment and shear can be obtained by placing $f_1 = 0$ in the equations of Art. 214. The values of L_s and L_t to be used for this case are given by eqs. (68) and (69) of Art. 206.

(f) Structure with Stiffening Truss Hinged at Ends and Centre.

218. Value of H.—The structure shown in Fig. 18, Art. 188, is also constructed so that the trusses are not continuous over the towers, as shown in Fig. 42. The main span has a centre hinge

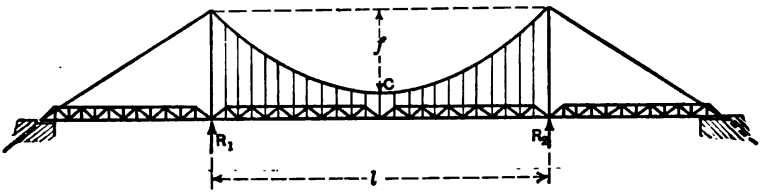

FIG. 42.

and at the towers the truss is anchored so as to take upward or downward reactions at these points. For this structure the methods used for the previous cases will not answer. When the cable is removed, the truss can carry no load on account of the centre hinge, so that the cable is no longer a redundant or superfluous member.

The stresses in this system are determined on the assumption that the cable is a parabola with the vertex at the centre under all conditions of loading. Therefore the hanger stresses are uniform over the entire span. The dead load is assumed to be carried entirely by the cable, the truss having no stress.

Under full live load the conditions will be similar to those for dead load, the cable carrying all the load, the trusses having no stress. At this time the cable stress is found as for the cable alone, as given in Sec. I, the horizontal component of stress being $\frac{p\,l^2}{8\,f}$ where p is the load per foot. For partial loads, the stiffening truss may be considered as a beam acted upon by the upward uniform pull of the hangers, and the distributed live load. As the cable is assumed to hang in a parabola, the pull of the hanger is found as in the previous cases to be $\frac{8\,f\,H}{l^2}$ lbs. per lin. ft. The stiffening truss removed and with all forces acting is shown in Fig. 43. Here the applied load is a uniform load of p lbs. per lin. ft. The reactions and stresses for this system may be deter-

mined by usual methods, subject to the added condition that moment at point B must be zero. From moments about A and C we have

$$R_1 = \frac{p\,(2-k)\,k\,l}{2} - \frac{4\,f\,H}{l} \quad . \quad . \quad . \quad . \quad (93)$$

$$R_2 = \frac{p\,k^2\,l}{2} - \frac{4\,f\,H}{l}. \quad . \quad . \quad . \quad . \quad . \quad . \quad . \quad (94)$$

The bending moment at any point of the section $A\,D$, where $x < k\,l$ is given by the expression

$$M = \frac{p\,(2-k)\,k\,l\,x}{2} - \frac{p\,x^2}{2} - \frac{4\,f\,H\,x}{l^2}\,(l-x) \quad . \quad . \quad (95)$$

and for the section $D\,C$, where $x > k\,l$

$$M = \frac{p\,k^2\,l}{2}\,(l-x) - \frac{4\,f\,H\,x}{l^2}\,(l-x). \quad . \quad . \quad . \quad . \quad (96)$$

From eqs. (95) and (96), it can be seen that the moment at any point in the truss is given by an expression of the form

$$M = M' - H\,y \quad . \quad . \quad . \quad . \quad . \quad . \quad (97)$$

where M' is the moment in a simple beam or span l, H is the horizontal component of the cable stress, and y is the cable ordinate at the moment

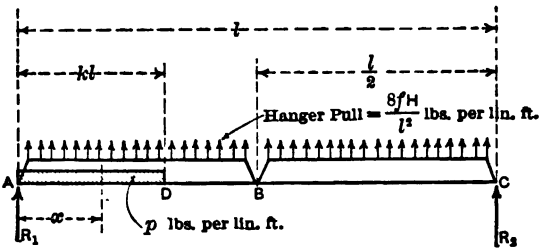

FIG. 43.

centre. This is the same expression as derived for the previous cases. Therefore, the same law of variation of moments holds for this structure, with the cable added, as for the structures already considered.

The value of H may be determined from eq. (96) by placing $M = 0$ at the centre, or for $x = \frac{l}{2}$ and $y = f$.

Then we have

$$H = \frac{p k^2 l^2}{4 f}, \quad . \quad . \quad . \quad . \quad . \quad . \quad . \quad (98)$$

which is the value of the horizontal component of the cable stress for a uniform load of p lbs. per lin. ft., extending a distance $k l$ from the left end of the span, where k is less than ½.

When the uniform load extends beyond the centre, or for k greater than ½, we find by a similar method that

$$H = \frac{p l^2}{8 f}(4 k - 2 k^2 + 1). \quad . \quad . \quad . \quad . \quad (99)$$

The maximum value of H will occur when $k = 1$ in eq. (99) or $H = \frac{p l^2}{8 f}$, which is the value for full load as stated above.

The general law expressed by eq. (97) can be shown to apply to concentrated loads also. The value of H for a single load P at a distance $k l$ from the left end of the span can be found from eq. (97) by placing $M = 0$, M' equal to the moment at the centre of a simple beam of span l for the load P, and $y = f$, from which we have

$$H = \frac{P k l}{2 f}. \quad . \quad . \quad . \quad . \quad . \quad . \quad . \quad (100)$$

This value of H will be a maximum for $k = ½$ when $H = \frac{P l}{4 f}$.

The values of R_1 and R_2 may be found from eqs. (93) and (94) by substituting H for the particular loading. For the loading shown in Fig. 43 we have from eqs. (98), (93), and (94)

$$R_1 = \frac{p k l}{2}(2 - 3 k) \quad . \quad . \quad . \quad . \quad . \quad (101)$$

$$R_2 = -\frac{p k^2 l}{2}. \quad . \quad . \quad . \quad . \quad . \quad . \quad (101a)$$

The maximum value of R_1 is found to occur for $k = ⅓$, when $R_1 = \frac{p l}{6}$.

219. Moments and Shears. Influence Lines.—The variation in moments and shears can be studied best from influence lines.

Moments.—For moments, eq. (97) may be written in the form

$$M = \left(\frac{M'}{y} - H\right) y \quad . \quad . \quad . \quad . \quad . \quad (102)$$

and influence lines drawn by the same methods as used for Fig. 24,

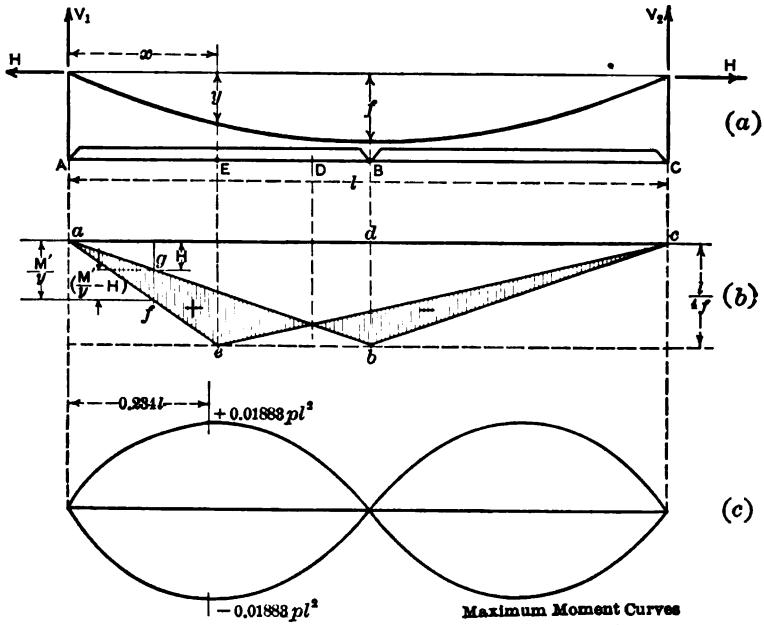

FIG. 44.

Art. 191. Here the value H is found for $P = 1$ lb. in eq. (100). The resulting curve is shown by the line $a\ b\ c$ of Fig. 44 (b).

The value of $\frac{M'}{y}$ is exactly the same as for the case shown in Fig. 24 and is shown here by the line $a\ e\ c$ of Fig. 44 (b), which is drawn for moment at point E.

The amount of the moment for any loading can be obtained by influence-line areas as explained in Arts. 192 and 205. For moment at the centre, the line, for $\frac{M'}{y}$ and H coincide, and the area between the

lines is zero. Therefore the moment at the centre is zero for all conditions of loading, which is as it should be, since the hinge can carry no moment.

The amount of the moment can also be obtained by substituting the value of H for the loading in question in eq. (95) or (96). Thus for maximum positive moment for any point to the left of the centre, the influence line shows that the loading is as given in Fig. 43. For this loading the value of H is given by eq. (98). Substituting this value of H in eq. (95) we have for $x < k\,l$

$$M = \frac{p\,k\,l}{2}(2 - 3\,k)\,x - \frac{p\,x^2}{2}(1 - 2\,k^2). \quad . \quad . \quad . \quad (103)$$

Placing $\frac{d\,M}{d\,k} = 0$ in eq. (103) we find that for maximum M

$$k = \frac{l}{3\,l - 2x}. \quad . \quad . \quad . \quad . \quad . \quad . \quad . \quad (104)$$

Substituting this value of k in eq. (103) we have

$$M = \frac{p\,x\,(l - 2\,x)\,(l - x)}{2\,(3\,l - 2x)}, \quad . \quad . \quad . \quad . \quad . \quad (105)$$

which gives the maximum value of M for any given value of x.

Again, placing $\frac{d\,M}{d\,x} = 0$ in eq. (105), we find that for absolute maximum M, the value of x is given by the equation

$$x^3 - 3\,l\,x^2 + \frac{9}{4}\,l^2\,x - \frac{3}{8}\,l^3 = 0. \quad . \quad . \quad . \quad . \quad (106)$$

From this equation the desired value of x is found to be $0.234\,l$. Then from eqs. (105) and (104) we find that the absolute maximum value of M is $+\,0.01883\,p\,l^2$, or about $\frac{1}{53}\,p\,l^2$, and that it occurs when $x = 0.234\,l$ and $k = 0.395$.

For negative moments at any point, the influence line shows that the load extends from one end of the span to a point beyond the centre hinge, for which case H is given by eq. (99). Substituting this value of H in eq. (96) the moment for $x > k\,l$ is found to be

$$M = \frac{p}{2}(l - x)\,[k^2\,(l + 2\,x) + x\,(1 - 4\,k)]. \quad . \quad . \quad . \quad (107)$$

Proceeding as before, we find that the absolute maximum value of this moment is $-0.01883\, p\, l^2$ or about $-\frac{1}{53}\, p\, l^2$, and that it occurs when $x = 0.766\, l$ and $k = 0.605$. The maximum value of the moment at any point in terms of x, as in eq. (105), is found to be

$$M = \frac{p\, x\, (l - x)\, (l - 2\, x)}{2\, (l + 2\, x)}. \quad . \quad . \quad . \quad . \quad . \quad (108)$$

In Fig. 44 (*c*) are shown the moment curves for maximum positive and negative moments. These values may be calculated from influence line areas or from eqs. (105) or (108).

Shears.—The law of variation of the shear at any point is given by the expression

$$V = V' - H \frac{d\, y}{d\, x} = V' - H \tan \theta \quad . \quad . \quad . \quad (109)$$

where the notation is the same as for previous cases. This expression may be written in the form

$$V = (V' \cot \theta - H) \tan \theta, \quad . \quad . \quad . \quad . \quad (110)$$

from which influence lines may be drawn as in Art. 194. The influence line for shear at point E of Fig. 45 is shown in Fig. 45 (*a*). The ordinates $c\, d$ and $d\, f$ have exactly the same values as given in Art. 194 for Fig. 24, while H is the same as for Fig. 44 (*b*).

From the influence lines it can be seen that for positive shear for points near the ends of the span, only the centre portion of one side of the span is to be loaded, as shown by Fig. 45 (*a*). This condition holds for points from the end of the span to the quarter point, as will be proved later. Beyond the quarter point the conditions are shown by Fig. (*c*).

The amounts of the shears can be determined by influence line areas as before, or by substituting in eq. (109).

For positive shears near the end of the span the influence line shows the loading to be as given in Fig. 46 (*a*). For the conditions shown

$$V'_B = \frac{p\, l}{2}\, (k - n)\, (2 - k - n) \quad \text{and} \quad H = \frac{p\, l^2}{4\, f}\, (k - n)\, (k + n).$$

Substituting these values in eq. (109) we find the shear at point B to be

$$V_B = \frac{p\,l}{2}(k - n)\,[2 - (3 - 4\,n)\,(k + n)]. \quad . \quad . \quad (111)$$

The value of k which makes this a maximum is found by placing $\frac{d\,V}{d\,k} = 0$, from which we have

$$k = \frac{1}{3 - 4\,n}. \quad . \quad . \quad . \quad . \quad . \quad . \quad . \quad (112)$$

This value substituted in eq. (111) gives

$$V_B = \frac{p\,l}{2}\,\frac{(1 - 3\,n + 4\,n^2)^2}{(3 - 4\,n)}, \quad . \quad . \quad . \quad . \quad (113)$$

which is the maximum value of V_B for any point B distance $n\,l$ from the left end of the span.

From Fig. 45 (b) it can be seen that this form of loading holds until $k = \frac{1}{2}$ at which time we find from eq. (112) that $n = \frac{1}{4}$. Thus eqs. (111) and (113) hold for values of n from 0 to $\frac{1}{4}$.

When $n = 0$, or for end shear, the influence line for which is shown in Fig. 45 (d), $k = \frac{1}{3}$ and $V = +\frac{p\,l}{6}$. For $n = \frac{1}{4}$, or shear at the quarter point, as shown by the influence line of Fig. 46 (b), $V = +\frac{p\,l}{16}$.

Negative shears at corresponding points are obtained by loading $A\,B$ and $C\,D$ of Fig. 46, no load on $B\,C$, as shown by the influence lines. Proceeding as for positive shears we find

$$V'_B = \frac{p\,l}{2}[(1 - k)^2 - n^2] \quad \text{and} \quad H = \frac{p\,l^2}{8\,f}(2\,n^2 - 2\,k^2 + 1).$$

Substituting these values in eq. (109), we find the value of the shear at point B, Fig. 46, to be

$$V_B = \frac{p\,l}{2}[(1 - k)^2 - n^2 - (1 - 2\,n)\,(2\,n^2 - 2\,k^2 + 1)], \quad (114)$$

which is found to be a maximum for $k = \frac{1}{3 - 4\,n}$ as before. Sub-

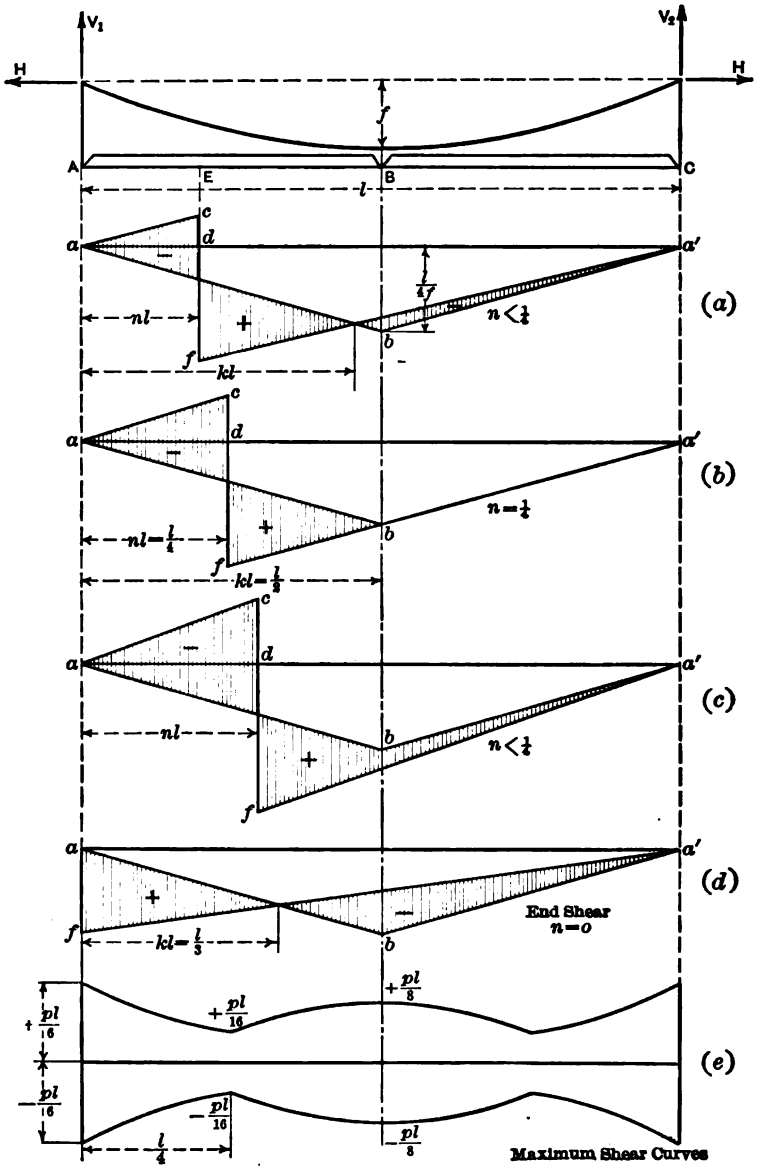

V1
V2
H
H
f
A
E
B
C
l
c
d
a
a'
nl
kl
b
f
n<1/4
(a)
nl=l/4
kl=l/2
n=1/4
(b)
(c)
kl=l/3
End Shear
n=o
(d)
+pl/16
+pl/8
+pl/6
-pl/16
-pl/8
-pl/6
l/4
(e)
Maximum Shear Curves

FIG. 45.

stituting this value of k in eq. (114) the maximum shear at B is

$$V_B = \frac{p\,l}{2}\left[\, n\,(4\,n^2 - 3\,n + 2) - \frac{1}{3 - 4\,n}\right]. \quad . \quad (115)$$

Eq. (115) is also found to hold for values of n from 0 to ¼. When $n = 0$, or for end shear, $V_B = -\frac{p\,l}{6}$, and for $n = ¼$, $V_B = -\frac{p\,l}{16}$. It will be seen that these values are numerically equal to the positive shears at the same points, but opposite in sign.

For positive shears at points beyond the quarter point the influence

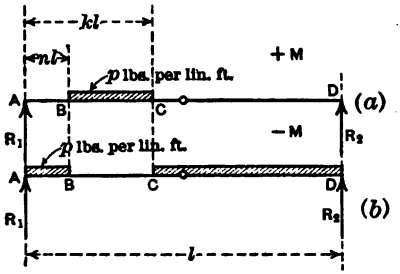

FIG. 46.

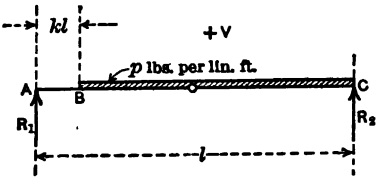

FIG. 47.

line, Fig. 45 (*c*), shows that the loading is as given in Fig. 47. Here $V'_B = \frac{p\,l}{2}(1 - k)^2$ and $H = \frac{p\,l^2}{8\,f}(1 - 2\,k^2)$.

Substituting in eq. (109) we find the shear at B to be

$$V_B = \frac{p\,k^2\,l}{2}(3 - 4\,k). \quad . \quad . \quad . \quad . \quad . \quad . \quad (116)$$

This is found to be a maximum for $k = ½$, or at the centre, where $V_B = +\frac{p\,l}{8}$. At the quarter point, $V_B = +\frac{p\,l}{16}$, as before. For negative shears, $A\,B$ of Fig. 47 is to be loaded, and we find

$$V_B = -\frac{p\,k^2\,l}{2}(3 - 4\,k). \quad . \quad . \quad . \quad . \quad . \quad (117)$$

Again, at the centre $V_B = -\frac{p\,l}{8}$, and at the quarter point $V_B = -\frac{p\,l}{16}$. The complete shear curves for positive and negative shears are shown in Fig. 45 (*e*).

220. Example. — For this case the main-span portion of the structure of Art. 205 will be used, a hinge being placed at the span centre.

Value of H. Under full live load, the value of H is given by eq. (99) of Art. 218 when $k = 1$.

$$H = \frac{p l^2}{8 f} = \frac{4{,}000 \times (1{,}446.7)^2}{8 \times 145.3} = 7{,}202{,}000 \text{ lbs.}$$

Moments and Shears.—The moments and shears at various points may be calculated by means of the formulas given in Art. 219.

The maximum moment is found to be $0.01883\, p l^2$. The actual value of this moment is then

$$0.01883 \times 4{,}000 \times (1{,}446.7)^2 = 157{,}640{,}000 \text{ ft.-lbs.}$$

The influence lines for moment and shear are given in Figs. 44 and 45.

(g) *Comparisons of Various Types of Structures*

221. Comparison of Results for Various Structures.—In order to determine approximately the relative merits of the various structures considered in the preceding articles, the maximum cable stress and the maximum moments at the centre and quarter points have been calculated and are given in the following table (page 275).

As these results have been calculated for the same span lengths and moments of inertia of trusses for all cases, a study of the table will indicate to some degree the relative economy of the different types.

From the table we see that the moments for the structure of Figs. 33 and 42 are less than for the others. At the quarter point, the positive moments, temperature included, are almost identical in each structure. For negative moments at the same point, the structure of Fig. 33 has a slight advantage over that of Fig. 42. At the centre point, the moment for the structure of Fig. 42 is zero because of the centre hinge. The fact that the truss of Fig. 33 is continuous over the centre of course makes it a more rigid structure. This aids it in resisting the action of wind forces on the side of the trusses, and, as sometimes happens, from underneath. The cable stresses in each of these cases are about the same, Fig. 42 having the advantage in that it is not affected by temperature changes. From the standpoint of stress calculation Fig. 42 has the advantage, for in this structure the stresses are all statically determinate, as in the three-hinge arch. The stresses in the case of Fig. 33 are determined by methods

COMPARISON OF RESULTS FOR VARIOUS STRUCTURES

Structure	Max. H in lbs.	H_t in lbs.	M_c in ft.-lbs.	M_t in ft.-lbs.	M_1 in ft.-lbs.	M_t in ft.-lbs.	Description of Structure
Fig. 26..	6,950,000	85,230	+ 107,800,000 − 76,400,000	± 12,380,000	+ 163,650,000 − 137,035,000	± 9,290,000	Three openings. Side spans suspn'd from cables.
Fig. 33..	6,963,000	89,200	+ 75,300,000 − 46,570,000	± 12,960,000	+ 146,650,000 − 122,020,000	± 9,724,000	Three openings. Side spans not suspended from cables
Fig. 34..	6,897,000	318,600	+ 151,520,000 — 36,575,000	± 16,500,000	+ 131,000,000 -- 69,500,000	± 8,070,000	Three openings. Trusses continuous over towers.
Fig. 38..	7,710,000	128,300	o	o	+ 169,150,000 − 180,000,000	± 4,660,000	Same as above with centre hinge.
Fig. 42..	7,202,000	o	o	o	± 157,640,000	o	Single opening, Centre hinge.

similar to those used for two-hinged arches, and are dependent upon the actual sections used. In the structure of Fig. 26, the moments are somewhat larger than in Figs. 33 and 42. Because of the suspended side spans the cable is a little more flexible than in the other cases, thus throwing a larger proportion of the load on the stiffening trusses, as shown by the increased moments. This type of structure is particularly useful in the case of long side spans for which it is not possible to provide intermediate supports. Also, in the case of side spans suspended from the cables, all the dead load may be assumed as taken by the cables, thus causing no stress in the truss. These spans can thus be made lighter than those of the structure of Fig. 33.

Structures with trusses continuous over the towers are seen to have moments and cable stresses which are greater than those in non-continuous structures. Their only advantage lies in their greater rigidity. In order to provide for linear expansion due to temperature, the tower connections must be so constructed that they will slide under temperature changes. Such joints are difficult to construct and also to maintain in good working condition. A great disadvantage in such systems is the difficulty in stress calculations. Such structures are threefold indeterminate, the moments at the towers, and the stress in the cable constituting the three unknowns.

(B) EXACT METHODS OF CALCULATION *

(*a*) *Structures with Trusses Hinged or Continuous at Towers*

222. Method of Procedure.—In structures in which the span is long and the trusses comparatively flexible, the effect of deflection under loads must be taken into account. In the general formula of Art. 187, the moment at any point in the stiffening truss was given as $M = M' - H\,y$. In this formula the deflection was neglected. If taken into account, the equation would read $M = M' - H\,(y + \eta)$, where η is the deflection at the point in question. From this equation it can be seen that the effect of this deflection is to reduce the amount of the moment, thus effecting a saving in material in the stiffening trusses. In the case of long spans this saving is considerable, as, for example, in the problem of Art. 205, the deflection was found to

* Based on the work of Melan, "Eiserne Bogenbrücken und Haengebrücken," Leipsic, 1888 and 1906. This method was fully developed by Mr. L. S. Moisseiff of the Department of Bridges of the City of New York, and used in the calculations of the Manhattan bridge, and again by the author, with various modifications, in the recalculations of this structure for the report of Mr. Ralph Modjeska to the City of New York. See also Max am Ende, in Proceedings Institution of Civil Engineers, 1898.

be almost 10 per cent of the centre sag. In the analysis to follow, values of moment, shear, and horizontal component of cable stress will be determined, taking into account the effect of deflection.

In deriving the equations the same general assumptions will be made as before, that is:

The initial curve of the cable will be assumed as parabolic.

The entire dead load will be assumed as carried by the cable, causing no stress in the stiffening trusses. The truss is stressed by live load, and by changes in temperature from the normal.

The notation used in the work to follow will, in general, be the same as in the preceding articles. For convenience this notation is repeated below:

H_w = horizontal component of cable stress due to dead load and mean temperature.

H = additional horizontal component of cable stress due to any cause, such as live load or temperature change.

η = deflection of truss and cable at any point from the normal position, due to H and any given live load (the effect of the stretch of the hangers is neglected. See Art. 228).

p = live load per unit length on part or all of the main or side span trusses.

w = dead load per unit length = load on cable, including its own weight.

M' = bending moment at any point in the truss due to the given live load, assuming the truss to be a simply supported beam.

M = actual bending in the truss at any point due to assumed conditions.

V = actual shear at any point.

I = moment of inertia of stiffening truss.

l = length of span.

f = centre sag of cable.

Subscripts will be used to indicate corresponding side span dimensions.

The general form of the structure to be considered will be as shown in Fig. 26, of Art. 200.

The main and side spans are suspended from the cable by hangers.

The trusses may or may not be continuous over the towers. However, the formulas will be developed on the assumption of non-continuous trusses. Continuity of trusses will modify only the values of the constants of Art. 224.

223. Derivation of Formulas for Deflection, Bending Moment, and Shear.—Under all conditions of loading the shape of the cable constitutes an equilibrium polygon for the hanger loads. If the horizontal component of the cable stress is $H_w + H$, the moment of the hanger stresses on the truss at any point A', Fig. 48, is therefore equal to

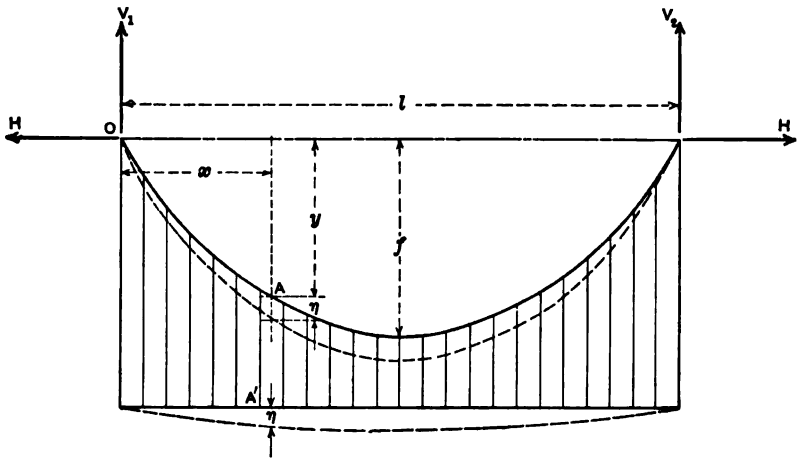

FIG. 48.

$(H_w + H)(y + \eta)$. But under the assumed conditions the portion $H_w y$ just balances the dead load; therefore the moment tending to balance the effect of the live load, or temperature change, is $(H + H_w)\eta + H y$. Hence the resultant moment in the stiffening truss due to this live load, or temperature change, is

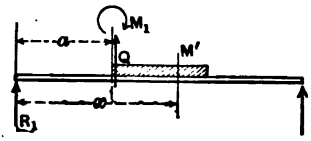

FIG. 49.

$$M = M' - (H + H_w)\eta - H y. \quad . \quad (1)$$

Consider any portion of the truss along which p and I may be assumed as constant, and suppose that the left end of this portion is at a distance a from the origin, Fig. 49. The value of M' at any point in this section can be written

$$M' = M_1 + Q(x - a) - \frac{p}{2}(x - a)^2,$$

in which M_1 is the bending moment and Q the shear at the left end of this section. Also, from the initial parabola, origin at O, Fig. 48, $y = \frac{4fx}{l^2}(l - x)$. Substituting these values in eq. (1), we have

$$M = M_1 + Q(x-a) - \frac{p}{2}(x-a)^2 - (H + H_w)\eta - H\left[\frac{4fx}{l^2}(l-x)\right] \quad . \quad (2)$$

With respect to the truss, the general relation of deflection to bending moment is

$$EI\frac{d^2\eta}{dx^2} = -M.$$

Substituting the value of M from eq. (2) in this expression, placing $\frac{H + H_w}{EI} = c^2$, we have

$$\frac{d^2\eta}{dx^2} = c^2\eta - \frac{c^2}{(H + H_w)}\left[M_1 + Q(x - a) - \frac{p}{2}(x - a)^2\right] + \frac{Hc^2}{(H + H_w)}\left[\frac{4fx}{l^2}(l-x)\right] \quad (3)$$

Integrating eq. (3), again substituting M' for brevity, we have *

$$\eta = \frac{H}{(H+H_w)}\left[C_1e^{cx} + C_2e^{-cx} + \frac{M'}{H} + \frac{1}{c^2}\left(\frac{8f}{l^2} - \frac{p}{H}\right) - \frac{4fx}{l^2}(l-x)\right] \quad (4)$$

which is the deflection at any point in the stiffening truss. C_1 and C_2 are integration constants to be determined from the conditions of the problem (Art. 224). Then from eq. (1), the bending moment at any point is

$$M = -H\left[C_1e^{cx} + C_2e^{-cx} + \frac{1}{c^2}\left(\frac{8f}{l^2} - \frac{p}{H}\right)\right]. \quad . \quad (5)$$

The shear at any point can be obtained by differentiating eq. (5), which gives

$$V = -Hc[C_1e^{cx} + C_2e^{-cx}]. \quad . \quad . \quad . \quad . \quad (6)$$

* Equation (3) may be written in the form $\frac{d^2\eta}{dx^2} = c^2\eta + c^2(a + bx + dx^2) = c^2\eta + c^2F(x)$. The integral of this is $\eta = A_1e^{cx} + A_2e^{-cx} - F(x) - \frac{1}{c^2}F''(x)$, in which A_1 and A_2 are integration constants and $F''(x)$ is the second derivative of $F(x)$. From this is written eq. (4), substituting $\frac{C_1H}{H + H_w}$ and $\frac{C_2H}{H + H_w}$ for A_1 and A_2.

Eqs. (4), (5), and (6) enable the deflections, moments, and shears to be calculated at any point in the main span for any given value of cable stress H and of load p on this span. The value of H to be used in these equations is given in Art. 225. For cases in which the deformation of the cable is known to be slight, the value of H as given by the Approximate Method, Art. 188, may be used.

From eqs. (4), (5), and (6), it can be seen that the deflection, moment, and shear at any point is no longer proportional to the load p. This is due to the fact that the horizontal component of the dead load cable stress, H_w, which existed before the advent of the live load, is involved in the quantity c, whose value is given by $c^2 = \frac{H + H_w}{EI}$. For this reason influence lines cannot be drawn for the above equations. In any case, however, the influence lines as drawn by the Approximate Method can be used as a guide in determining maximum values. Then by several trials with about the same loading as required by the Approximate Method, the maximum is easily found.

The formulas for deflection, moment, and shear are applicable to side spans by using the span length l_1, and the centre sag f_1, for these spans in place of the corresponding main span values l and f. The value of c is also to be used in terms of side-span quantities. This value is then $c^2{}_1 = \frac{H + H_w}{EI_1}$.

Eqs. (4), (5), and (6) may also be applied to structures in which the trusses are continuous over the towers. This may be done by making proper provision for this continuity in the term M' of eq. (4). The values of M' are the same as given in Figs. 35 and 39 of Art. 214.

In the previous work it has been assumed that the hanger pull due to live load is uniform over the entire length of the cable for the span in question. The exact amount of live load taken by the stiffening truss in any case may now be found by taking the second derivative of the moment for the given loading; that is, the load per unit length $= -\frac{d^2 M}{dx^2}$. From eq. (5), the load taken by the stiffening truss is, therefore,

$$-\frac{d^2 M}{dx^2} = c^2 H [C_1 e^{-cx} + C_2 e^{-cx}]. \quad . \quad . \quad . \quad (7)$$

If p is the live load per unit length, the amount of load taken by the hangers is

$$\text{Hanger Pull} = s_1 = p - c^2 H [C_1 e^{cx} + C_2 e^{-cx}]. \quad . \quad (8)$$

Eq. (8) is the general formula for hanger pull. For any particular condition of loading, the constants C_1 and C_2 must be determined for that case.

224. Constants of Integration.—The quantities C_1 and C_2 in eqs. (4), (5), (6), and (8) are constants of integration which must be determined for each different case of loading. Thus for each different value of p or I, there is a corresponding set of constants C_1 and C_2.

For a uniform load p per unit length throughout, and constant I, C_1 and C_2 are obtained from the two conditions that for $x = 0$ and $x = l$ in eq. (5), $M = 0$. Substituting these values, we have

$$C_1 + C_2 + \frac{1}{c^2}\left(\frac{8f}{l^2} - \frac{p}{H}\right) = 0.$$

and

$$C_1 e^{cl} + C_2 e^{-cl} + \frac{1}{c^2}\left(\frac{8f}{l^2} - \frac{p}{H}\right) = 0.$$

We have here two independent equations involving the unknowns C_1 and C_2, from which we find

$$C_1 = -\frac{1}{c^2 (e^{cl} + 1)}\left(\frac{8f}{l^2} - \frac{p}{H}\right) \quad . \quad . \quad . \quad . \quad (9)$$

$$C_2 = C_1 e^{cl} \quad . \quad . \quad . \quad . \quad . \quad . \quad . \quad . \quad . \quad (10)$$

which are the constants of integration for the main span fully loaded.

For a uniform load of p per unit of length extending a distance $k\,l$ from the left end of the span, as shown in Fig. 50, the constants of integration for the loaded section $A\,B$ and for the unloaded section $B\,C$, may be determined at the same time. The constants for the loaded section will be denoted by C_1 and C_2; those for the unloaded portion by C_3 and C_4. The additional equations now required for the four constants are obtained from the condition that the moments and shears at the right end of section $A\,B$ of Fig. 50 are equal to those at the left end of section $B\,C$. The values of these constants will now be determined.

From eqs. (5) and (6) the moments and shears for the various sections are given by the following expressions:

$$M_{AB} = -H\left[C_1 e^{cx} + C_2 e^{-cx} + \frac{1}{c^2}\left(\frac{8f}{l^2} - \frac{p}{H}\right)\right] \quad . \quad (A)$$

$$M_{BC} = -H\left[C_3 e^{cx} + C_4 e^{-cx} + \frac{8f}{c^2 l^2}\right] \quad . \quad . \quad . \quad . \quad (B)$$

$$V_{AB} = -Hc\,[C_1 e^{cx} - C_2 e^{-cx}] \quad . \quad . \quad . \quad . \quad . \quad . \quad (C)$$

$$V_{BC} = -Hc\,[C_3 e^{cx} - C_4 e^{-cx}] \quad . \quad . \quad . \quad . \quad . \quad . \quad (D)$$

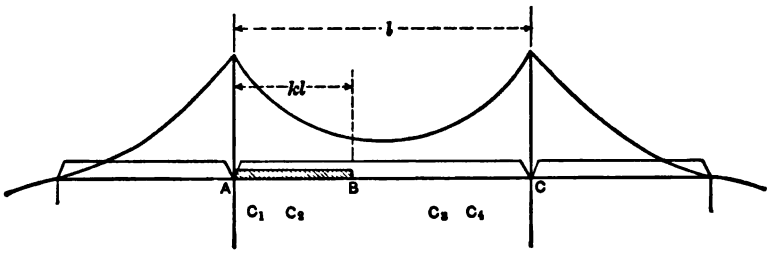

FIG. 50.

The conditions from which the independent equations are to be made up. are as follows:

For $x = o$, $M = o$ in eq. (A)
$x = l$, $M = o$ in eq. (B)
$x = kl$, eq. (A) = eq. (B)
$x = kl$, eq. (C) = eq. (D).

Substituting these conditions in eqs. (A) to (D), the independent equations are found to be

$$C_1 + C_2 + \frac{1}{c^2}\left(\frac{8f}{l^2} - \frac{p}{H}\right) = o$$

$$C_3 e^{cl} + C_4 e^{-cl} + \frac{8f}{c^2 l^2} = o$$

$$C_1 e^{kcl} + C_2 e^{-kcl} + \frac{1}{c^2}\left(\frac{8f}{l^2} - \frac{p}{H}\right) = C_3 e^{kcl} + C_4 e^{-kcl} + \frac{8f}{c^2 l^2}$$

$$C_1 e^{kcl} - C_2 e^{-kcl} = C_3 e^{kcl} - C_4 e^{-kcl}$$

From these equations, the values of the various constants are given by

$$C_1 = \frac{\frac{p}{2Hc^2}\left[e^{cl(1-k)} + e^{-cl(1-k)} - 2e^{-cl}\right] - \frac{8f}{c^2 l^2}\left(1 - e^{-cl}\right)}{\left(e^{cl} - e^{-cl}\right)} \quad . \quad (11)$$

$$C_2 = -C_1 - \frac{1}{c^2}\left(\frac{8f}{l^2} - \frac{p}{H}\right) \quad . \quad (12)$$

$$C_3 = C_1 - \frac{p}{2Hc^2}e^{-kcl} = \frac{\frac{p}{2Hc^2}\left[e^{-cl}\left(e^{kcl} + e^{-kcl} - 2\right)\right] - \frac{8f}{c^2 l^2}\left(1 - e^{-cl}\right)}{\left(e^{cl} - e^{-cl}\right)} \quad (13)$$

$$C_4 = -C_3 e^{2cl} - \frac{8f}{c^2 l^2}e^{cl}. \quad . \quad (14)$$

When eqs. (4), (5), and (6) are used to calculate deflection, moment, or shear, the proper values of C_1 and C_2 are to be substituted as determined for the loading in question. Thus for the loading shown in Fig. 50, the deflection, moment, or shear at any point in section $A\,B$ is found by substituting values of C_1 and C_2 as given by eqs. (11) and (12). For corresponding values in the unloaded portion $B\,C$, the values of the constants are given by C_3 and C_4 of eqs. (13) and (14), C_3 and C_4 replacing C_1 and C_2 respectively. For this section, the value of p in eqs. (5) and (6) is to be taken as zero, as no live load exists on this section.

For other conditions of loading, such as are apt to arise in the calculation of stresses in any structure, the values of the constants of integration are found by a process similar to that given above. Values of these constants for various cases have been worked out and are given on Plates I to IV, pp. 290–293.

The values of the constants for side-span conditions are exactly similar to those for corresponding main-span conditions. The values are given in terms of side-span dimensions.

Trusses Continuous over Towers.—For this case the constants of integration are determined by equating the moments at the towers for main span with those for side span, and the deflections at the towers equal to zero.

225. Formula for H.—In most cases it is desirable to use a formula for horizontal component of cable stress which will give

results more exact than those given by the Approximate Method. For this purpose a formula for H will be derived in which the deflection of the truss and cable are taken into account.

The cable stress, H, may be caused by a load on either main or side spans, or by temperature change. In deriving an expression for H the entire cable, anchorage to anchorage, must be considered. Imagine the hangers to be cut just below the cable and their stresses replaced by external forces. The total load per unit of length acting on the cable after advent of live load, or temperature change, will be equal to s_1. The application of this live load, or temperature change, will cause the cable to stretch, and will also cause vertical displacements along the cable, some downward and some upward. The total work performed in this vertical movement must be equal to the total work done in stretching the cable, which may be divided into two parts, one part due to changes in the stress in the cable, and the other part due to temperature changes.

Work in the Cable Due to Stress.—Let A be the constant area of the cable, and $d\,s$ an increment of length. The stress at any point in the cable due to H is then $H\frac{d\,s}{d\,x}$. The stretch of the element is $\frac{H}{A\,E}\frac{d\,s}{d\,x}d\,s$. The average total stress in the cable at the same point during the application of the load is $\left(\frac{H}{2}+H_w\right)\frac{d\,s}{d\,x}$, and hence the work done on this element is $\left(\frac{H}{2}+H_w\right)\frac{H}{A\,E}\frac{d\,s^2}{d\,x^2}$. The total work on the cable may then be written

$$\left(\frac{H}{2}+H_w\right)\frac{H}{A\,E}\int_0^l\frac{d\,s^2}{d\,x^2}. \quad . \quad . \quad . \quad . \quad . \quad (A)$$

In this equation the expression $\int_0^l\frac{d\,s^2}{d\,x^2}$ is the same as already worked out in Art. 188 and referred to as L_s. This notation will again be used.

Work in the Cable Due to Temperature Change.—Let ω be the coefficient of expansion, and t the change in temperature. The change

in length of any element ds is $\omega t\, ds$, and the average stress is again $\left(\frac{H}{2} + H_w\right)\frac{ds}{dx}$, hence the total work in the whole cable is

$$\left(\frac{H}{2} + H_w\right)\omega t \int_0^l \frac{ds^2}{dx}. \quad . \quad . \quad . \quad . \quad . \quad (B)$$

The expression $\int_0^l \frac{ds^2}{dx}$ is again the same as given in Art. 188, and there called L_t.

Total Work in the Cable.—From eqs. (*A*) and (*B*) the total work in the cable is given by

$$\left(\frac{H}{2} + H_w\right)\frac{H L_s}{A E} + \left(\frac{H}{2} + H_w\right)\omega t L_t. \quad . \quad . \quad (15)$$

Work Done by Vertical Displacement.—The load per unit length of the cable is s_1 and the movement is η, as given by eq. (4). Hence the work done is $\int s_1 \eta\, dx$. The dead load is uniformly distributed along the cable, and for the purpose of calculating $\int s_1 \eta\, dx$, the additional load may also be assumed as uniformly distributed. Then s_1 may be found from the fact that the load per unit length is equal to the second derivative of the moment caused by the load. In this case the moment in terms of H caused by the load on the cable (neglecting the increment of deflection due to the additional load) will be $(H + H_w)\, y$, where $y = \frac{4fx}{l^2}(l - x)$. Then we have

$$M = (H + H_w)\frac{4fx}{l^2}(l - x),$$

and

$$s_1 = -\frac{d^2 M}{dx^2} = +(H + H_w)\frac{8f}{l^2} \text{ (approximately).}$$

The average load on the cable will then be $\left(\frac{H}{2} + H_w\right)\frac{8f}{l^2}$. The work in the cable of the main span is therefore given by the expression

$$\frac{8f}{l^2}\left(\frac{H}{2} + H_w\right)\int_0^l \eta\, dx. \quad . \quad . \quad . \quad . \quad . \quad (C)$$

A similar expression must be derived for the side spans. This expression will be of the same form as that for the main span, given in terms of side-span dimensions. It is therefore

$$\frac{8 f_1}{l_1^2}\left(\frac{H}{2}+H_w\right)\int_o^{l_1}\eta_1\, d\,x. \quad . \quad . \quad . \quad . \quad (D)$$

The total work in the main span, and both side spans is then

$$\frac{8 f}{l^2}\left(\frac{H}{2}+H_w\right)\left[\int_o^{l}\eta\, d\,x+\frac{2 f_1 l^2}{f l_1^2}\int_o^{l_1}\eta_1\, d\,x\right]. \quad . \quad (16)$$

Expression for H.—Equating the expression for work in the cable, as given by (15), with that of vertical displacement, as given by (16), placing $\frac{f_1 l^2}{f l_1^2}=K$, we have

$$\left(\frac{H}{2}+H_w\right)\frac{H L_s}{A E}+\left(\frac{H}{2}+H_w\right)\omega t L_t=\frac{8 f}{l^2}\left(\frac{H}{2}+H_w\right)\left[\int_o^{l}\eta\, d\,x+2K\int_o^{l_1}\eta_1\, d\,x\right] \quad (17)$$

Substituting the value of η from eq. (4), integrating known values of functions containing x, and solving for H, we derive the general expression

$$H=\frac{\int_o^{l}\left(M'-\frac{p}{c^2}\right)dx+K\left[\begin{matrix}\text{Term for}\\ \text{Side Spans}\end{matrix}\right]-\frac{l^2\omega t}{8 f}H_w L_t}{-\int_o^{l}(C_1 e^{cx}+C_2 e^{-cx})\,dx-\frac{8f}{c^2 l^2}+\frac{2}{3}fl+2K\left[\begin{matrix}\text{Terms for}\\ \text{Side Spans}\end{matrix}\right]+\frac{c^2 I l^2}{8 f A}L_s+\frac{l^2\omega t}{8 f}L_t}. \quad (18)$$

which is the horizontal component of the cable stress for a general case.

The terms in brackets in eq. (18) indicate that terms for each side span are to be written out exactly similar to the preceding terms for the main span. If there are no loads in any span, then the values of M' and p for that span are zero. It is to be noted that in eq. (18), the quantities C_1 and C_2, and also c, contain the quantity H so that the value of H can be obtained only by successive approximations.

Simplified Formula for H.—The expression for H given in eq. (18) can be simplified somewhat, for any particular form of loading, as the constants C_1 and C_2, and also any similar constants which may be involved, can be expressed in detail and some of the terms containing H transferred to the first member of the equation. Then by solving this equation for H, an expression somewhat more convenient of application that eq. (18) can be obtained. This sim-

plified formula for H will now be worked out for the condition of loading shown in Fig. 50.

The terms in eq. (18) which depend upon the conditions of loading for their value are $\int_o^l \left(M' - \frac{p}{c^2}\right) dx$, $- \int_o^l (C_1 e^{cx} + C_2 e^{-cx})\, dx$, and the corresponding side-span terms.

For the loading shown in Fig. 50, the term $\int_o^l \left(M' - \frac{p}{c^2}\right) dx$ takes the form

$$\int_o^l \left(M' - \tfrac{p}{c^2}\right) dx = \int_o^{kl} \left[\tfrac{p\,kl}{2}(2-k)x - \tfrac{p\,x^2}{2} - \tfrac{p}{c^2}\right] dx + \int_{kl}^{l} \left[\tfrac{p\,k^2 l}{2}(l-x)\right] dx = p\,kl\left[\tfrac{k\,l^2}{12}(3-2k) - \tfrac{1}{c^2}\right]. \quad . \quad (19)$$

Since, for the assumed loading, the side spans have no load, the corresponding side span terms are zero.

The term $- \int_o^l (C_1 e^{cx} + C_2 e^{-cx})\, dx$ is to be made up for the main and side spans. For the main span, the values of these constants are given in eqs. (11) to (14) of Art. 224. Performing the required integrations, substituting the values of the constants, and reducing, we have

$$-\int_o^l (C_1 e^{cx} + C_2 e^{-cx})\, dx = -\int_o^{kl} (C_1 e^{cx} + C_2 e^{-cx})\, dx$$

$$-\int_{kl}^{l} (C_3 e^{cx} + C_4 e^{-cx})\, dx = \frac{1}{c}\left\{C_1 (2 - e^{cl} - e^{-cl}) + \frac{p}{2Hc^2}[e^{cl(1-k)} + e^{-cl(1-k)} - 2 + 2e^{-cl}] + \frac{8f}{c^2 l^2}(1 - e^{-cl})\right\}$$

$$= \frac{1}{c(e^{cl} - e^{-cl})}\left\{\frac{p}{Hc^2}[e^{cl(1-k)} + e^{-cl(1-k)} - e^{cl} - e^{-cl} - e^{kcl} - e^{-kcl} + 2] + \frac{16f}{c^2 l^2}(e^{cl} - 2 + e^{-cl})\right\}. \quad . \quad . \quad (20)$$

The corresponding side-span terms will be of the form

$$-2K \int_o^{l_1} (B_1 e^{c_1 x} + B_2 e^{-c_1 x})\, dx,$$

where B_1 and B_2 are the side-span constants. The values of these constants will be similar to those for the main span given in eqs. (9)

and (10), except that p is zero as there is no load on these spans. Proceeding as for the main span, we have

$$-2K\int_0^{l_1}(B_1 e^{c_1 x} + B_2 e^{-c_1 x})\,dx = -\frac{4KB_1}{c_1}(e^{c_1 l_1} - 1)$$

$$= +\frac{32K}{c_1^3 l_1^2}\frac{(e^{c_1 l_1} - 1)}{(e^{c_1 l_1} + 1)}. \quad \ldots\ldots \quad (21)$$

Substituting the values of the expressions given in eqs. (19), (20), and (21) in eq. (18), and solving for H, we have finally,

$$H = \frac{pkl\left[\frac{k\beta^2}{12}(3-2k)-\frac{1}{c^2}\right] - \frac{p}{c^2(e^{cl}-e^{-cl})}\left[e^{cl(1-k)}+e^{-cl(1-k)}-e^{cl}-e^{-cl}-e^{kcl}-e^{-kcl}+2\right] - \frac{\beta^2\omega t}{8f}H_w L_t}{\frac{16f}{c^3\beta^2}\frac{(e^{cl}-1)}{(e^{cl}+1)} - \frac{8f}{c^2 l} + \frac{2}{3}fl + K\left[\frac{32f_1}{c_1^3 l_1^2}\frac{(e^{c_1 l_1}-1)}{(e^{c_1 l_1}+1)} - \frac{16f_1}{c_1^2 l_1} + \frac{4}{3}f_1 l_1\right] + \frac{c^2 I\beta^2}{8fA}L_s + \frac{\beta^2\omega t}{8f}L_t} \quad (22)$$

which is the simplified form of the expression for the horizontal component of cable stress for the loading conditions shown in Fig. 50.

For any other condition of loading, the value of H can be found by a similar process. On Plates I to IV are given such values for various conditions of loading. In these expressions the denominator is abbreviated by the letter "D," with a subscript $+t$ or $-t$, denoting a rise or fall in temperature.

Value of the Denominator of eq. (22).—It will be found on comparison of the various expressions for H, that one result of the above transformation has been to make the denominator of all such expressions identical in form. All changes due to the various conditions of loading now appear in the numerator of the expression for H. The denominator of eq. (22) may then be determined separately, and hereafter used as a coefficient in the various expressions. Its value is

$$D = \frac{16f}{c^3\beta^2}\frac{(e^{cl}-1)}{(e^{cl}+1)} - \frac{8f}{c^2 l} + \frac{2}{3}fl + K\left[\frac{32f_1}{c_1^3 l_1^2}\frac{(e^{cl}-1)}{(e^{cl}+1)} - \frac{16f_1}{c_1^2 l_1} + \frac{4}{3}f_1 l_1\right] + \frac{c^2 I\beta^2}{8fA}L_s \pm \frac{\beta^2\omega t}{8f}L_t. \quad (23)$$

The temperature term, $\frac{\beta^2\omega t}{8f}L_t$, will be positive for a rise in temperature and negative for a fall. Hereafter, eq. (23) will be referred to as D_{+t} for temperature conditions above the normal, and D_{-t}

for those below the normal. It is to be noted that D_{+t} and D_{-t} are dependent upon H for their values, because of the quantities c and c_1 which appear therein. To facilitate calculation by means of the modified formulas, the denominator as given by eq. (23) may be calculated, and tabulated or plotted for future reference. Such curves of values are given in Fig. 51.

226. Conditions of Loading for Maximum Moments and Shears. Tables of Values.—The effect of the loading conditions on the value of the moment at any point can be determined by a study of eq. (1) of Art. 223.

For positive moments at any point, eq. (1) shows that the value of M' is to be as large as possible, while H is to be small at the same time. In general it will be found that this condition is realized when the centre of moments and the adjacent portions of the span in question are covered with live load, no load on the rest of the structure. The temperature conditions existing at the same time must be such as to reduce the value of H. From eq. (22) we see that a rise in temperature is necessary to realize this condition.

For negative moments at any point, the value of M' is to be as small as possible, while H is to be large at the same time. In general this condition is realized when there is no load on the portion of the structure adjacent to the moment centre, conditions opposite to those for positive moments. The temperature conditions must be such as to increase the value of H. Eq. (22) shows that a fall in temperature is necessary.

The shear at any point is given by the equation

$$\frac{dM}{dx} = V = V' - H \tan \theta$$

where the notation is the same as given in Art. 190.

From this equation we find, by a process similar to that given for moments, that similar loading conditions hold for shears as for moments.

The loading conditions found to exist for the Approximate Method can be used as a guide for corresponding results by the Exact Method. By determining the loading conditions from influence lines as given in Arts. 191 and 194 and then applying exact methods, it is usually possible after one or two trials to arrive at the correct conditions

PLATE I

MAXIMUM POSITIVE MOMENTS AND SHEARS, CENTER SPAN

CASE I.

Maximum Positive Moments; End to near Center.
Maximum Positive Shears; End, and near Center

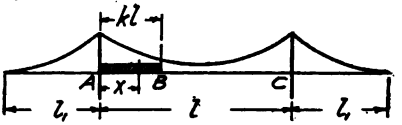

Conditions of Loading

Main Span; Partially Loaded
Side Spans; No Load
Temperature; Highest.

$$H = \frac{pkl\left[\frac{k^2l^2}{12}(3-2k) - \frac{1}{c^2}\right] - \frac{P}{c^3(e^{cl}-e^{-cl})}\left[e^{cl(1-k)} + e^{-cl(1-k)} - e^{cl} - e^{-cl} - e^{kcl} - e^{-kcl} + 2\right] - \frac{l^2 w_t H_w}{8f} L_t}{D + t}$$

Section A to B

$$C_1 = \frac{\frac{P}{2Hc^2}\left[e^{cl(1-k)} + e^{-cl(1-k)} - 2e^{-cl}\right] - \frac{8f}{c^2l^2}(1-e^{-cl})}{(e^{cl}-e^{-cl})}$$

$$C_2 = -C_1 - \frac{1}{c^2}\left(\frac{8f}{l^2} - \frac{P}{H}\right)$$

CASE II

Maximum Positive Moments near Center
Maximum Positive Shears, End to near Center
Maximum Downward Deflection of Center Point.

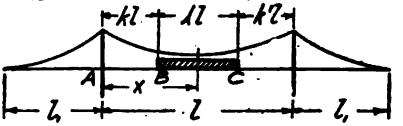

Conditions of Loading

Main Span; Partially Loaded
Side Spans; No Load
Temperature; Highest

$$H = \frac{pl\left\{l^2\left[\frac{k(1-k)+k'(1-k')}{4} + \frac{\lambda^2}{12} - \frac{1}{c^2}\right] + \frac{P}{c^2(e^{cl}-e^{-cl})}\left[e^{cl(1-k)} + e^{-cl(1-k)} + e^{cl(1-\lambda)} + e^{-cl(1-\lambda)} - e^{kcl} - e^{-kcl} - e^{k'cl} - e^{-k'cl}\right] - \frac{l^2 w_t H_w}{8f} L_t}{D + t}$$

Section B to C

$$C_1 = \frac{\frac{P}{2Hc^2}\left[e^{k'cl} + e^{-k'cl} - (e^{kcl} + e^{-kcl})e^{-cl}\right] - \frac{8f}{c^2l^2}(1-e^{-cl})}{(e^{cl}-e^{-cl})}$$

$$C_2 = -C_1 + \frac{P}{2Hc^2}(e^{kcl} + e^{-kcl}) - \frac{8f}{c^2l^2}$$

PLATE II

MAXIMUM NEGATIVE MOMENTS AND SHEARS, CENTER SPAN

CASE III

Maximum Negative Moments; End to near Center.
Maximum Negative Shears; End, and near Center.

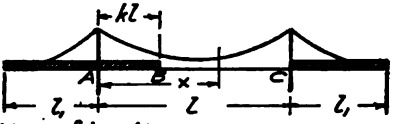

Conditions of Loading
Main Span: Partially Loaded
Side Spans: Fully Loaded
Temperature; Lowest.

$$H = \frac{pl\left[\frac{kl}{l'^2}(3-2k)-\frac{1}{c^2}\right]-\frac{p}{c^2(e^{cl}-e^{-cl})}\left[e^{cl(1+k)}-e^{cl(1-k)}-e^{cl}-e^{-cl}-e^{kcl}+e^{-kcl}+2\right]+2pl\left[\frac{l^2}{l'^2}-\frac{1}{c^2}\right]+\frac{4p(e^{cl}-1)}{c^3(e^{cl}+1)}+\frac{\bar{t}\omega t H_{\omega}}{Af}L_t}{D-t}$$

Section B to C

$$C_1 = \frac{\frac{p}{2Hc^2}\left[e^{-cl}(e^{kcl}+e^{-kcl}-2)\right]-\frac{8f}{c^2l'^2}(1-e^{-cl})}{(e^{cl}-e^{-cl})}$$

$$C_2 = -C_1 e^{2cl} - \frac{8f}{c^2l'^2}e^{cl}$$

CASE IV

Maximum Negative Moments near Center
Maximum Negative Shears, End to near Center

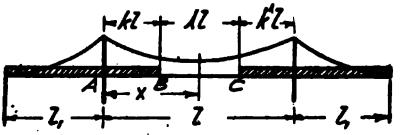

Conditions of Loading
Main Span; Partially Loaded
Side Spans; Fully Loaded
Temperature; Lowest

$$H = \frac{pl\left[\frac{l^2}{l'^2}-\frac{1}{c^2}\right]+2pl\left[\frac{l^2}{l'^2}-\frac{1}{c^2}\right]+\frac{2p(e^{cl}-1)}{c^3(e^{cl}+1)}+\frac{4p(e^{cl}-1)}{c^3(e^{cl}+1)}-\left[\text{Numerator Case II}\right]}{D-t}$$

Section B to C

$$C_1 = \frac{\frac{p}{2Hc^2}\left[(e^{kcl}+e^{-kcl})e^{-cl}-e^{kcl}-e^{-kcl}\right]-\frac{1}{c^2}\left(\frac{8f}{l'^2}-\frac{p}{H}\right)(1-e^{-cl})}{(e^{cl}-e^{-cl})}$$

$$C_2 = -C_1 - \frac{p}{2Hc^2}\left(e^{kcl}+e^{-kcl}\right)-\frac{1}{c^2}\left(\frac{8f}{l'^2}-\frac{p}{H}\right)$$

PLATE III

MAXIMUM POSITIVE MOMENTS AND SHEARS, SIDE SPANS

CASE V

Maximum Positive Moments; Loaded Side Span.

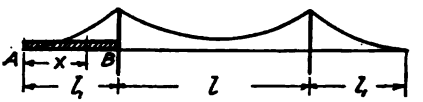

Conditions of Loading

Main Span; No Load
Side Spans; One, Fully Loaded; Other, No Load.
Temperature; Highest.

$$H = \frac{p l_1\left(\frac{l_1^2}{12} - \frac{1}{c_1^2}\right) + \frac{2p}{c_1^3}\frac{(e^{c_1 l_1} - 1)}{(e^{c_1 l_1} + 1)} - \frac{l^2 w t H_w}{8f} L_t}{D + t}$$

Section A to B

$$C_1 = -\frac{1}{c_1^2(e^{c_1 l_1} + 1)}\left(\frac{8f_1}{l_1^2} - \frac{p}{H}\right)$$

$$C_2 = C_1 e^{c_1 l_1}$$

CASE VI

Maximum Positive Shears; Partially Loaded Side Span

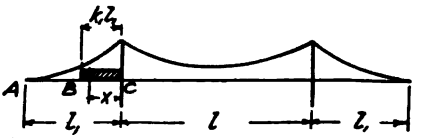

Conditions of Loading

Main Span; No Load
Side Spans; One, Partially Loaded; Other, No Load.
Temperature; Highest

$$H = \frac{pk_1 l_1\left[\frac{k_1^2 l_1^2}{12}(3 - 2k_1) - \frac{1}{c_1^2}\right] - \frac{p}{c_1^3(e^{c_1 l_1} - e^{-c_1 l_1})}\left[e^{c_1 l_1(1-k_1)} + e^{-c_1 l_1(1-k_1)} - e^{c_1 l_1} - e^{-c_1 l_1} + e^{-k_1 c_1 l_1} + e^{k_1 c_1 l_1} + 2\right] - \frac{l^2 w t H_w}{8f} L_t}{D + t}$$

Section B to C

$$C_1 = \frac{\frac{p}{2Hc_1^2}\left[e^{c_1 l_1(1-k_1)} + e^{-c_1 l_1(1-k_1)} - 2e^{-c_1 l_1}\right] - \frac{8f}{c_1^2 l_1^2}(1 - e^{-c_1 l_1})}{(e^{c_1 l_1} - e^{-c_1 l_1})}$$

$$C_2 = -C_1 - \frac{1}{c_1^2}\left(\frac{8f}{l^2} - \frac{p}{H}\right)$$

PLATE IV

MAXIMUM NEGATIVE MOMENTS AND SHEARS, SIDE SPANS

CASE VII

Maximum Negative Moments; Unloaded Side Span

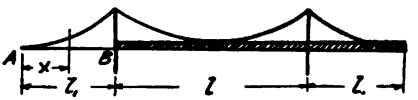

Conditions of Loading

Main Span; Fully Loaded
Side Spans; One, No Load; Other, Fully Loaded
Temperature; Lowest

$$H=\frac{pl_1^2\left(\frac{l^2}{12}-\frac{1}{c^2}\right)+pl_1\left(\frac{l_1^2}{12}-\frac{1}{c_1^2}\right)+\frac{2p}{c^3}\frac{(e^{cl}-1)}{(e^{cl}+1)}+\frac{2p}{c_1^3}\frac{(e^{cl_1}-1)}{(e^{cl_1}+1)}+\frac{l^2wtH_w}{8f}L_t}{D-t}$$

Section A to B

$$C_1=-\frac{1}{c_1^2(e^{cl_1}+1)}\frac{8f_1}{l_1^2}$$

$$C_2=C_1e^{cl_1}$$

CASE VIII

Maximum Negative Shears, Partially Loaded Side Span

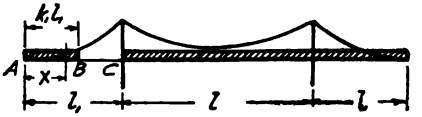

Conditions of Loading

Main Span; Fully Loaded
Side Spans; One, Partially Loaded; Other, Fully Loaded
Temperature; Lowest

$$H=\frac{pk_1l_1\left[\frac{k_1^2l_1^2}{12}(3-2k_1)-\frac{1}{c_1^2}\right]-\frac{P}{c_1^3(e^{cl}-e^{-cl_1})}\left[e^{cl}e^{cl_1(1-k_1)}+e^{-cl_1}e^{-cl_1(1-k_1)}-e^{cl}e^{-cl}-e^{cl}e^{-cl}-e^{k_1cl_1}e^{-k_1cl_1}+2\right]+[\text{Numerator Case VII}]}{D-t}$$

Section A to B

$$C_1=\frac{\frac{P}{2Hc_1^2}\left[e^{cl}e^{cl_1(1-k_1)}+e^{-cl}e^{cl_1(1-k_1)}-2e^{cl}e^{-cl}\right]-\frac{8f_1}{c_1^2l_1^2}(1-e^{-cl_1})}{(e^{cl}-e^{-cl_1})}$$

$$C_2=-C_1-\frac{1}{c_1^2}\left(\frac{8f_1}{l_1^2}-\frac{P}{H}\right)$$

of loading. Problems bringing out these points will be given in Art. 227.

To aid in the calculation of moments and shears for a structure of the type of the Manhattan Suspension Bridge, formulas for H have been derived for the various cases of loading which arise. These formulas are given on Plates I to IV. In calculating moments and shears eqs. (5) and (6) are to be used. The values of C_1 and C_2 which are to be used are also given on the Plates, together with the necessary temperature conditions.

227. Example.—The exact methods of Arts. 223 to 226 will now be applied to the calculation of horizontal component of cable stress, moment, shear, and deflection in the case of the Manhattan Suspension Bridge. The dimensions of the structure are as given in Fig. 30 of Art. 205. The live load in all cases will be taken as 4,000 lbs. per lin. ft. per truss.

Values of Denominator D.—As stated in Art. 225, the value of the denominator is constant for all cases. The values of D_{+t} and D_{-t} as given by eq. (23), were calculated for values of H ranging from 0 to 6,000,000, and for temperature conditions 55 degrees above and below the normal. The curves plotted from these results are shown in Fig. 51. From these curves the value of the denominator for any particular value of H can be determined, thus reducing the labor of calculation.

Values of Horizontal Component of Cable Stress.—The value of H for a uniform load of 4,000 lbs. per ft., extending from the left end of the main span to the quarter point, will be calculated to illustrate the methods employed. From Case I, Plate I, the formula for H for this case, temperature considered as above normal, is,

$$H = \frac{pkl\left[\frac{kl^2}{12}(3-2k)-\frac{1}{c^2}\right] - \frac{p}{c^3(e^{cl}-e^{-cl})}\left[e^{cl(1-k)}+e^{-cl(1-k)}-e^{cl}-e^{-cl}-e^{kcl}-e^{-kcl}+2\right]-\frac{l^2\omega t H_w}{8f}L_t}{D_{+t}}.$$

This equation can be solved only by successive approximations, for the term c, whose value is given by $c^2 = \frac{H + H_w}{EI}$, also contains H. In the solution of this equation, a value of H is assumed, from which the value of c is calculated and substituted above. If the value of H was correctly assumed, the result of the substitution will equal the assumed value. Usually after one or two trials, a result is obtained for which the assumed and calculated values of H differ by only a small amount, which should be limited to 1 per cent.

For the problem in question, assume H = 665,000 lbs. The value of H_w is given by $\frac{wl^2}{8f}$. For the dimensions given in Fig. 30, with the dead

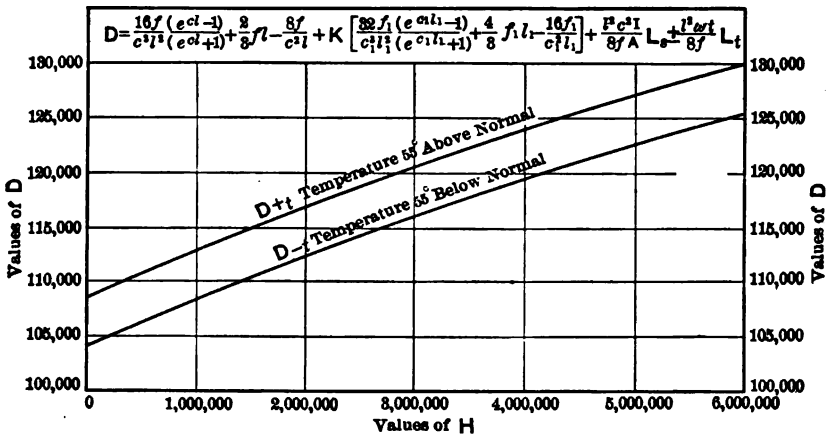
$D=\frac{16f}{c^2l^2}\frac{(e^{cl}-1)}{(e^{cl}+1)}+\frac{2}{3}\frac{8f}{c^2l}-\frac{8f}{c^2l}+K\left[\frac{32f_1}{c_1^2l_1^2}\frac{(e^{c_1l_1}-1)}{(e^{c_1l_1}+1)}+\frac{4}{3}\frac{8f_1}{c_1^2l_1}l_1-\frac{16f_1}{c_1^2l_1}\right]+\frac{l^2c^2I}{8fA}L_s\pm\frac{l^2wt}{8f}L_t$
D+t Temperature 55° Above Normal
D−t Temperature 55° Below Normal
Values of D
Values of H
130,000
125,000
120,000
115,000
110,000
105,000
100,000
0
1,000,000
2,000,000
3,000,000
4,000,000
5,000,000
6,000,000

FIG. 51.

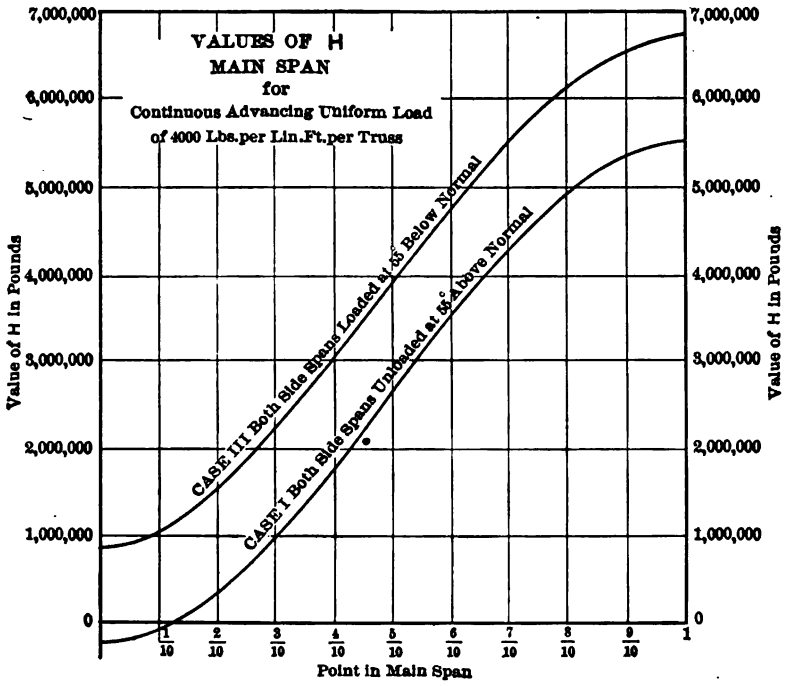
VALUES OF H
MAIN SPAN
for
Continuous Advancing Uniform Load
of 4000 Lbs. per Lin. Ft. per Truss
CASE III Both Side Spans Loaded at 55° Below Normal
CASE I Both Side Spans Unloaded at 55° Above Normal
Value of H in Pounds
Point in Main Span
7,000,000
6,000,000
5,000,000
4,000,000
3,000,000
2,000,000
1,000,000
0
1/10
2/10
3/10
4/10
5/10
6/10
7/10
8/10
9/10
1

FIG. 52.

load on the main and side spans taken respectively as 5,820 and 6,130 lbs. per ft., we have

$$\frac{w l^2}{8 f} = \frac{5{,}820 \times (1446.7)^2}{8 \times 145.3} = 10{,}480{,}000 \text{ lbs.}$$

$$\frac{w_1 l_1^2}{8 f_1} = \frac{6{,}130 \times (713.5)^2}{8 \times 37.2} = 10{,}480{,}000 \text{ lbs.}$$

Taking the average of these values, we find $H_w = 10{,}480{,}000$ lbs.

The moment of inertia of the main span is given as 43,900 ft.^{2} ins.^{2} With $E = 29{,}000\,000$ lbs. per sq. in., we find

$$c^2 = \frac{H + H_w}{EI} = \frac{10{,}480{,}000 + 665{,}000}{43{,}900 \times 29{,}000{,}000} = 0.000008754,$$

from which $c = 0.0029587$. Also, $\frac{I}{c} = 337.98$, $\frac{I}{c^2} = 114{,}230.6$, and $\frac{I}{c^3} = 38{,}607{,}000$.

For $k = 0.25$, $p = 4{,}000$, $l = 1446.7$, we have

$$p\,k\,l\left[\frac{k\,l^2}{12}(3 - 2\,k) - \frac{I}{c^2}\right] = -\,7{,}556{,}260{,}000.$$

The values of the terms containing e^{cl} and e^{kcl} are best found by logarithms ($\log e = 0.4342945$). With $c = 0.0029587$, we have $cl = 4.2805$, from which $\log e^{cl} = 1.858967$. The values of e^{kcl} are found by multiplying $\log e^{cl}$ by k. The values of the various terms are given in the following table:

$\log e^{cl} = 1.858967$	$e^{cl} = 72.2714$	$e^{-cl} = 0.0138.$
$\log e^{\frac{1}{4}cl} = 0.464742$	$e^{\frac{cl}{4}} = 2.9157$	$e^{-\frac{cl}{4}} = 0.3430.$
$\log e^{(1-\frac{1}{4})cl} = 1.394225$	$e^{\frac{3}{4}cl} = 24.7870$	$e^{-\frac{3}{4}cl} = 0.0403.$

For these values the second term in the numerator of the formula for H becomes

$$-\frac{p}{c^3(e^{cl} - e^{-cl})}[-48.7167] = +\,104{,}118{,}350{,}000.$$

The value of the temperature term in the numerator is found to be

$$\frac{l^2\,\omega\,t\,H_w}{8 f} L_t = -\,22{,}720{,}000{,}000$$

where $L_t = 3452$ (from Art. 205), $\omega = 0.0000066$, and $t = +\,55°$.

The total for the numerator is $+\,73{,}842{,}100{,}000$.

From the curve of Fig. 51 for D_{+t}, we find the value of the denominator for $H = 665{,}000$ to be, $D_{+t} = 111{,}300$. The resulting value of H is then 663,400 lbs. As this value is within 0.25 per cent of the assumed H, it will be taken as final.

Values of H for a continuous advancing uniform load of 4,000 lbs. per lin. ft. for Cases I and III, as given on Plates I and II, have been calculated, and are plotted in Fig. 52. It will be noted in the curve in Case I, that the

effect of temperature above the normal, no load on the structure is such as to decrease the amount of the dead load cable stress. This effect also occurs under loading out to about the $\frac{1}{8}$ point.

Moment at Quarter Point.—The general expression for moment at any point, as given by eq. (5) of Art. 223, is

$$M = -H\left[C_1 e^{cx} + C_2 e^{-cx} + \frac{1}{c^2}\left(\frac{8f}{l^2} - \frac{p}{H}\right)\right]$$

The constants of integration for loading conditions which give maximum positive moments at the quarter point are found under Case I, on Plate I. The values are,

$$C_1 = \frac{\frac{p}{2Hc^2}\left[e^{cl(1-k)} + e^{-cl(1-k)} - 2e^{cl}\right] - \frac{8f}{c^2 l^2}\left(1 - e^{-cl}\right)}{e^{cl} - e^{-cl}}$$

$$C_2 = -C_1 - \frac{1}{c^2}\left(\frac{8f}{l^2} - \frac{p}{H}\right).$$

In the problem of Art. 205, the loading for maximum positive moment at the quarter point was found to extend from the end of the span to $k = 0.466$. Using this as a guide, the moments were calculated by the above equations for $k = 0.400$, 0.425, 0.450, and 0.475, from which the maximum was found to occur for $k = 0.425$. For the various cases, the value of H was taken from the curves of Fig. 52. For $k = 0.425$ we find $H = 2{,}022{,}000$ lbs. For this value of H we have $c^2 = 0.000009821$ and $c = 0.003134$. The various terms in the above equation then have the following values:

$$e^{cl} = e^{4.5340} = 93.111 \qquad e^{-cl} = 0.0105$$

$$e^{cl(1-k)} = e^{0.575\,cl} = 13.555 \qquad e^{-cl(1-k)} = 0.0738$$

$$\frac{p}{2Hc^2} = 100.710 \qquad \frac{8f}{c^2 l^2} = 56.552$$

With these values we find

$$C_1 = \frac{100.710\ [13.555 + 0.0738 - 0.0210] - 56.552\ (1 - 0.0105)}{(93.111 - 0.0105)} = +14.119$$

$$C_2 = -14.119 - \frac{1}{0.000009821}(0.0005554 - 0.0019782) = +130.750.$$

For moment at the quarter point, we have $x = \frac{l}{4}$. Then $e^{cx} = e^{\frac{cl}{4}} = 3.106$ and $e^{-\frac{cl}{4}} = 0.322$. Substituting these values in the general expression, together with the values of C_1 and C_2, we have

$$M = -2{,}022{,}000\,[14.119 \times 3.106 + 130.75 \times 0.322 + \frac{1}{0.000009821}(0.0005554 - 0.0019782)]$$

$$= +119{,}110{,}000 \text{ ft.-lbs.}$$

By the approximate method, the positive moment at the quarter point, temperature effect included, was found to be 172,940,000 (Problem, Art. 205). This result exceeds the value given above by 45 per cent.

Moment at Centre.—The maximum moment at the centre of the main span was found to occur for a uniform load extending from $k = 0.3$ to $k = 0.7$. The formula for H and the values of the constants of integration are given under Case II on Plate I. In the determination of the values of H, trial values were obtained by taking the difference between the ordinates at the ends of the load, as given by the curves of Fig. 52. The final value of H was usually found on the second substitution in the formula. By a process similar to that used for moment at the quarter point, the maximum positive centre moment was found to be 89,710,000 ft. lbs. The final value of H was 3,155,000 lbs., and the constants of integration were found to be $C_1 = 1.806$, and $C_2 = 205.602$.

The Approximate Method result of Art. 205, temperature effect included, exceeds the moment given above by 33.9 per cent.

Shear at the End of Main Span.—The maximum positive shear at the left end of the main span was found to occur for a uniform load extending from the left end of the span to $k = 0.325$.

The general formula for shear at any point is given by eq. (6) of Art. 223.

$$V = - H c [C_1 e^{cx} - C_2 e^{-cx}].$$

The formula for H, and the values of the constants of integration are given under Case I, on Plate I. From the curve of Fig. 52, the value of H was found to be 1,200,000 lbs. With this value of H we find $c = 0.003029$, $C_1 = 43.05$, and $C_2 = 259.72$. At the end of the span, where $x = 0$, we have, $e^{cx} = 1$ and $e^{-cx} = 1$. The shear is then

$$V = - 1{,}200{,}000 \times 0.003029\ (+43.05 - 259.72) = + 787{,}500 \text{ lbs.}$$

Deflection of Centre Point.—The maximum downward deflection of the centre point will be found to occur for the main span fully loaded, no load on the side spans, temperature highest. The general equation for deflection is given by eq. (4) of Art. 223. Placing $x = \frac{l}{2}$ and $M' = \frac{p l^2}{8}$ in this equation, we have

$$\eta = \frac{H}{H + H_w}\left[C_1 e^{\frac{cl}{2}} + C_2 e^{-\frac{cl}{2}} + \frac{p l^2}{8 H} + \frac{1}{c^2}\left(\frac{8 f}{l^2} - \frac{p}{H}\right) - f\right].$$

From the curves of Fig. 52, the value of H for the main span fully loaded, temperature above normal, is found to be 5,470,000 lbs. The value of c is then 0.003594. The constants of integration are given under Case II, on Plate I, with k and $k' = 0$, or by Case I for $k = 1$. We then have

$$C_1 = - \frac{1}{c^2 (e^{cl} + 1)} \frac{8 f}{l^2} \qquad C_2 = C_1 e^{cl}.$$

For the value of H given above we find

$$C_1 = + 0.07711 \quad C_2 = + 13.96.$$

Substituting in the above equation, the deflection is found to be

$\eta = 0.34295\ [0.07711 \times 13.445 + 13.96 \times 0.07432 + 191.31 - 14.04 - 145.3]$
$= 11.677$ ft.

228. Effect of Extension of Hangers.—In the formulas for deflection, moment, and cable stress H, as given in Arts. 223 and 225, the effect of the elongation of the hangers was neglected. It was assumed that the cable and the truss deflected equal distances. If, in any case, the hangers elongate under loading, the movement of the cable will differ from that of the truss by the amount of the hanger elongation. Let $d\,h$ be the elongation of the hanger at any point. Taking this elongation into account in eq. (1) the moment at any point due to the hanger loads is given by the expression,

$$M = M' - (H + H_w)(\eta - d\,h) - H\,y \quad . \quad . \quad (24)$$

The extension of the hanger at any point due to stress is given by

$$d\,h = \frac{8\,f\,H\,F_x}{l^2\,A_h\,E_h}$$

where $\frac{8\,f\,H}{l^2}$ is the hanger pull per unit of length along the truss; A_h is the area of hangers per unit of length along the truss, considering that the hangers are close together forming a continuous sheet; E_h is the coefficient of elasticity; and F_x is the length of a hanger at any point. In Art. 188, the length of the hanger at any point was found from Fig. 21 to be $F_x = F_c + f - \frac{4\,f\,x}{l^2}(l - x)$, where F_c is the length of the main span centre hanger. Then we have for the extension due to stress

$$d\,h = \frac{8\,f\,H}{l^2\,A_h\,E_h}\left[F_c + f - \frac{4\,f\,x}{l^2}(l - x)\right]$$

Temperature changes also affect the length of the hangers. For a change of t degrees, coefficient of linear expansion ω_h, the elongation is $\omega_h\,t\,F_x$. The total elongation due to stress and temperature in the main span is then

$$d\,h = \left(\frac{8\,f\,H}{l^2\,A_h\,E_h} + \omega_h\,t\right)\left[F_c + f - \frac{4\,f\,x}{l^2}(l - x)\right]. \quad (25)$$

Proceeding as in Art. 223, the differential equation of the elastic curve of the stiffening truss is found to be

$$\frac{d^2\eta}{dx^2} = c^2(\eta - dh) - \frac{c^2}{(H+Hw)}\left[M_1 + Q(x-a) - \frac{p}{2}(x-a)^2\right] + \frac{Hc^2}{(H+Hw)}\left[\frac{4fx}{l_2}(l-x)\right] \quad (26)$$

Integrating eq. (26), inserting the value of $d\,h$ as given by eq. (25), we have

$$\eta = \frac{H}{(H+Hw)}\left\{C_1e^{cx} + C_2e^{-cx} + \frac{M'}{H} - \frac{4fx}{l^2}(l-x) + \left(\frac{8fH}{l^2A_hE_h} + \omega_h l\right)\left[Fc + f - \frac{4fx}{l^2}(lx)\right]\right.$$
$$\left.\frac{(H+Hw)}{H} + \frac{1}{c^2}\left\{\frac{8f}{l^2}\left[1 + \frac{(H+Hw)}{H}\left(\frac{8fH}{l_2A_hE_h} + \omega_h l\right)\right] - \frac{p}{H}\right\}\right\} \quad . \quad . \quad (27)$$

which is the deflection at any point in the stiffening truss when the extension of the hangers is taken into account.

Substituting in eq. (24) the value of η from eq. (27) and of $d\,h$ from eq. (25), we have

$$M = -H\left\{C_1e^{cx} + C_2e^{-cx} + \frac{1}{c_2}\left\{\frac{8f}{l_2}\left[1 - \frac{(H+Hw)}{H}\left(\frac{8fH}{l_2A_hE_h} + \omega_h l\right)\right] - \frac{p}{H}\right\}\right\} \quad (28)$$

which is the value of the moment at any point. This expression differs from that given in eq. (5) only in the term

$$\frac{(H + H_w)}{H}\left(\frac{8fH}{l^2A_hE_h} + \omega_h l\right)$$

This term can be shown to be so small that it can be neglected in most cases. In this expression, the term $(H + H_w)\,\frac{8f}{l^2A_h}$ represents the unit stress in the hangers, which may be taken approximately as 30,000 lbs. per sq. in. Then for E_h = 15,000,000 lbs. per sq. in., the value of this term is

$$\frac{H + H_w}{H}\,\frac{8fH}{l^2A_hE_h} = \frac{30{,}0000}{15{,}000{,}000} = \frac{1}{5{,}000} = 0.0002.$$

Also the term $\frac{(H + H_w)}{H}\,\omega_h l$ may be taken as approximately equal to $\omega_h l$, or $55 \times 0.0000065 = 0.0003$. As the sum of these two terms is very small compared to 1, their effect can be neglected.

The shear at any point is found by taking the first derivative of eq. (28) with respect to x. The resulting expression is exactly the same as given in eq. (6) of Art. 223. The effect of the extension of the

hangers on the shear is then due to whatever change in the value of H is caused by this effect.

In deriving an expression for H in which the effect of the extension of the hangers is taken into account, the work done in the elongation of the hangers must be added to that done in the cable. The work in the cable due to temperature and stress is given in eq. (6) of Art. 223. The effect of the extension of the hangers on the shear is then due to whatever change may occur in the value of H.

In deriving an expression for H in which the effect of the extension of the hangers is taken into account, the work done in the elongation of the hangers must be added to that done in the cable. The work in the cable due to temperature and stress is given by eq. (15) of Art. 225. The part to be added for the hangers is equal to the hanger stress multiplied by the extension of the hangers. The average total hanger stress is $\left(\frac{H}{2} + H_w\right)\frac{8f}{l^2}$. The extension of the hangers is given by eq. (25). The work done in the main span is $\left(\frac{H}{2} + H_w\right)\frac{8f}{l^2}\int dh$. The average total work is then

$$\left(\frac{H}{2} + H_w\right)\frac{8f}{l^2}\left(\frac{8fH}{l_2 A_h E_h} + \omega_h t\right)\int_0^l \left[F_c + f - \frac{4fx}{l^2}(l - x)\right]dx$$

$$= \left(\frac{H}{2} + H_w\right)\left(\frac{8fH}{l^2 A_h E_h} + \omega_h t\right)\left(F_c + \frac{f}{3}\right)\frac{8f}{l}$$

Adding this expression to that given in eq. (15) we have as the total:

$$\left(\frac{H}{2} + H_w\right)\left[\frac{H L_s}{A E} + \omega t L_t + \left(\frac{8fH}{l^2 A_h E_h} + \omega_h t\right)\left(F_c + \frac{f}{3}\right)\frac{8f}{l}\right]. \quad (29)$$

The average work of displacement is given by

$$\frac{8f}{l^2}\left(\frac{H}{2} + H_w\right)\int_0^l (\eta - dh)\, dx.$$

Substituting values of η and dh, and integrating known values of $f(x)$, we have as the external work,

$$\left(\frac{H}{2} + H_w\right)\left\{\frac{H}{(H + H_w)}\left[\int_0 (C_1 e^{cx} + C_2 e^{-cx})dx + \frac{1}{H}\int_0^l \left(M' - \frac{p}{c^2}\right)dx - \frac{2}{3}fl\right.\right.$$

$$\left.\left. + \frac{8f}{c^2 l^2}\left[1 + \frac{(H + H_w)}{H}\left(\frac{8fH}{l_2 A_h E_h} + \omega_h t\right)\right]\right]\right\}. \quad (30)$$

Placing eq. (29) equal to eq. (30) and solving for H, we have

$$H = \frac{\int_0^l \left(M' - \frac{p}{c^2}\right) dx - \frac{l^2}{8f}\omega t H_w \left[L_t + \frac{\omega_h}{\omega}\left(F_c + \frac{f}{3} - \frac{8f}{c^2 l^2}\right)\frac{8f}{l}\right]}{-\int_0^l (C_1 e^{\alpha x} + C_2 e^{-\alpha x}) dx + \frac{2}{3} fl - \frac{8f}{c^2 l^2} + \frac{c^2 l^2 I}{8f A}\left[L_s + \frac{64 f^2 AE}{l^2 A_h E_h}\left(F_c + \frac{f}{3} - \frac{8f}{c^2 l^2}\right)\right] + \frac{l^2}{8f}\omega t \left[L_t + \frac{\omega_h}{\omega}\left(F_c + \frac{f}{3} - \frac{8f}{c^2 l^2}\right)\frac{8f}{l}\right]} \quad (31)$$

As in the case of moments, it can be shown that the effect of the terms due to elongation of the hangers are so small that they can be neglected. From eq. (31) it can be seen that the effect of hanger elongation will be the greatest when the term $\frac{8f}{c^2 l^2}$ has its least value, or when $\frac{I}{c^2}$ is smallest. This is found to occur for full load on the span in question, for which case $\frac{8f}{c^2 l^2} = 44.3$. Then we have for dimensions given in Fig. 30

$$\frac{\omega_h}{\omega}\left(F_c + \frac{f}{3} - \frac{8f}{c^2 l^2}\right)\frac{8f}{l} = 1\left(31.4 + \frac{145.3}{3} - 44.3\right) 0.804 = 28.5$$

when $\frac{\omega_h}{\omega}$ is taken equal to unity.

From Art. 205 the value of L_t for the main span only is given as 1540.5. The effect of the hangers is then to add to L_t a term equal to about 1¾ per cent of L_t. In the case of the term which is to be added to L_s we have for values similar to those used in Art. 205

$$\frac{64 f^2 AE}{l^2 E_h E_h}\left(F_c + \frac{f}{3} - \frac{8f}{c^2 l^2}\right) = \frac{64 \times (145.3)^2 \times 275 \times 29{,}000{,}000}{(1446.7)^2 \times 0.36 \times 16{,}000{,}000}\left(31.4 + \frac{145.3}{3} - 44.3\right) = 23.8$$

The value of L_s for main span is given in Art. 205 as 1583.3 so that the effect of hanger elongation adds only 1⅓ per cent to this term. From this we see that the effect of hanger elongation on the value of H can be neglected without material error.

In the above equations the effect of the side-span hangers has not been included. These terms for the side spans are similar in form to the corresponding main-span values.

229. Effect of Variable Moment of Inertia.—In calculating the stresses in the stiffening trusses, it is usually assumed that the moment of inertia is constant over the whole truss. The moment curves as

calculated by the Approximate Method, in Art. 205, show that the moment is quite variable, and as the sections of the truss, as actually constructed, are made up to fit the calculated moments, the assumption of uniform moment of inertia is not correct.

The effect of this variation in moment of inertia may be taken into account by dividing the truss into short sections in which the load p and the moment of inertia I, may be considered constant. Then by determining the values of the constants of integration C_1 and C_2 for any section, the moment may be calculated from eq. (5). The conditions for the formation of the independent equations from which C_1 and C_2 are to be determined are obtained by placing the moments and the shears at the end of one section equal to those at the beginning of the next. This is an application of the same method as used in Art. 224 in the determination of the constants of integration for a truss with uniform moment of inertia.

This method will now be applied to the determination of the moment at the quarter point of the main span of the Manhattan Sus-

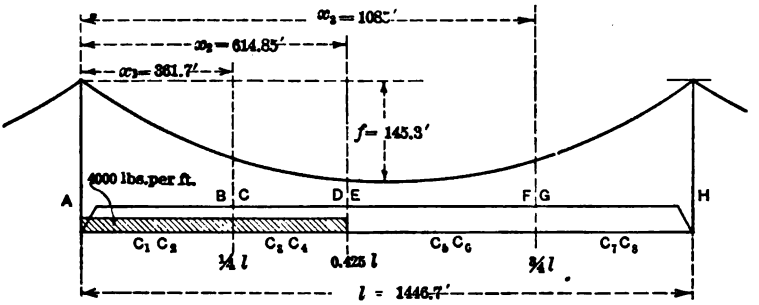

FIG. 53.

pension Bridge. For this purpose the loaded length, and the value of H, will be taken as calculated in the problem of Art. 227. See Fig. 53.

From the general drawings of the structure, it was found that the variation in moment of inertia was such that its effect could be represented by dividing the truss into four equal sections. The average value of the moment of inertia of the section from the ends out to the quarter points was found to be 35,100 ft.^{2} in.^{2}, and for the section

from quarter point to quarter point, the average value was 47,150 ft.^{2} in.^{2}

Substituting these values in the expression $c = \frac{H + H_w}{E I}$, we find $\frac{1}{c_1} = 285.34$ and $\frac{1}{c_2} = 330.71$, where c_1 and c_2 represent the values obtained from the above expression for the end and centre sections respectively.

The four sections into which the truss is divided on account of changes in loading and moment of inertia are shown in Fig. 53.

As in Art. 224, there will be two constants of integration similar to C_1 and C_2 for each section, thus making eight values to be determined.

The independent equations for the determination of these values are found from eqs. (5) and (6) of Art. 223 by substituting values of c and x for each section. We then have

$$C_1+C_2+\frac{1}{c_1^2}\left(\frac{8f}{l^2}-\frac{p}{H}\right)=0 \quad . \quad . \quad . \quad . \quad . \quad . \quad . \quad . \quad . \quad . \quad . \quad (A)$$

$$C_1 e^{c_1 x_1}+C_2 e^{-c_1 x_1}+\frac{1}{c_1^2}\left(\frac{8f}{l^2}-\frac{p}{H}\right)=C_3 e^{c_2 x_1}+C_4 e^{-c_2 x_1}+\frac{1}{c_2^2}\left(\frac{8f}{l^2}-\frac{p}{H}\right) \quad (B)$$

$$C_3 e^{c_2 x_2}+C_4 e^{-c_2 x_2}+\frac{1}{c_2^2}\left(\frac{8f}{l^2}-\frac{p}{H}\right)=C_5 e^{c_2 x_2}+C_6 e^{-c_2 x_2}+\frac{1}{c_2^2}\frac{8f}{l^2} \quad . \quad . \quad (C)$$

$$C_5 e^{c_2 x_3}+C_6 e^{-c_2 x_3}+\frac{1}{c_2^2}\frac{8f}{l^2}=C_7 e^{c_1 x_3}+C_8 e^{-c_1 x_3}+\frac{1}{c_1^2}\frac{8f}{l^2} \quad . \quad . \quad . \quad . \quad (D)$$

$$C_7 e^{c_1 l}+C_8 e^{-c_1 l}+\frac{1}{c_1^2}\frac{8f}{l^2}=0 \quad . \quad . \quad . \quad . \quad . \quad . \quad . \quad . \quad . \quad . \quad . \quad (E)$$

$$c_1[C_1 e^{c_1 x_1}-C_2 e^{-c_1 x_1}]=c_2[C_3 e^{c_2 x_1}-C_4 e^{c_2 x_1}] \quad . \quad . \quad . \quad . \quad . \quad . \quad (F)$$

$$c_2[C_3 e^{c_2 x_2}-C_4 e^{-c_2 x_2}]=c_2[C_5 e^{c_2 x_2}-C_6 e^{-c_2 x_2}] \quad . \quad . \quad . \quad . \quad . \quad . \quad (G)$$

$$c_2[C_5 e^{c_2 x_3}-C_6 e^{-c_2 x_3}]=c_1[C_7 e^{c_1 x_3}-C_8 e^{-c_1 x_3}]. \quad . \quad . \quad . \quad . \quad . \quad (H)$$

For values of c, as given above, and of x as shown in Fig. 53, the terms of the form e^{cx} and e^{-cx} have the values given in Table A. These values are obtained by the method used in the problem of Art. 227.

The terms of the form $\frac{1}{c^2}\left(\frac{8f}{l^2}-\frac{p}{H}\right)$ and $\frac{8f}{c^2 l^2}$ have the following values for the various sections.

Section A to B — $\frac{1}{c_1^2}\left(\frac{8f}{l^2} - \frac{p}{H}\right) = -115.843.$

Section G to H — $\frac{8f}{c_1^2 l^2} = +45.220.$

Section C to D — $\frac{1}{c_2^2}\left(\frac{8f}{l^2} - \frac{p}{H}\right) = -155.612.$

Section E to F — $\frac{8f}{c_2^2 l^2} = +60.744.$

Substituting these values, together with the values of e^{cx} as given

TABLE A

Point.	Term.	e^{cx}	e^{-cx}
A	$e^{c_1 x_0}$	1	1
B	$e^{c_1 x_1}$	3.5522	0.28151
C	$e^{c_2 x_1}$	2.9850	0.33501
D	$e^{c_2 x_2}$	6.4180	0.15581
E	$e^{c_2 x_2}$	6.4180	0.15581
F	$e^{c_2 x_3}$	26.5980	0.03759
G	$e^{c_1 x_3}$	44.8230	0.02310
H	$e^{c_1 l}$	159.1900	0.00628

in Table A, in the independent equations, (A) to (H), we have the equations given in Table B.

Here each equation is given in the form

$$A C_1 + B C_2 + \ldots\ldots = \text{absolute term}$$

where A, B, etc., are the values of the terms e^{cx} and e^{-cx} as given in Table A. In eqs. (6), (7), and (8) the terms of the form e^{cx} are divided by $\frac{1}{c}$ to form the various coefficients.

From the solution of these equations the values of the various constants of integration are obtained. The solution is given in Table C. In this table the equations of Table B have been transformed so that the coefficient of one of the constants is unity. This transformed equation has the same number as before with a prime. By the addition or subtraction of these equations, the lettered equations, a, b, etc., are obtained, thus eliminating one of the unknowns. Again, a transformed equation a', b', etc., is obtained from a, b, etc., and the

TABLE B

INDEPENDENT EQUATIONS

No. of Equation.	C_1	C_2	C_3	C_4	C_5	C_6	C_7	C_8	Absolute Term.
1	+1.0	+1.0	.....	.....	.....	.....	.....	.....	+115.843
2	+3.5522	+0.28151	−2.9850	−0.33501					− 39.769
3	.....	.....	+6.4180	+0.15581	− 6.4180	−0.15581	.....	.....	+216.356
4	.....	.....	.....	.....	+26.5980	+0.03759	− 44.8230	−0.02231	− 15.524
5	.....	.....	.....	.....	.....	.....	+159.1900	+0.00628	− 45.220
6	+0.012448	−0.0009866	−0.009026	+0.0010130	.....	.....	.....	.....	0
7	.....	.....	+6.4180	−0.15581	− 6.4180	+0.15581	.....	.....	0
8	.....	.....	.....	.....	+0.08425	−0.00011368	−0.15708	+0.00007819	0

TABLE C

SOLUTION OF EQUATIONS

No. of Equation.	C_1	C_2	C_3	C_4	C_5	C_6	C_7	C_8	Absolute Term.
1′	+1.0	+1.0	.....	.....	.....	.....	.....	.....	+ 115.843
2′	+1.0	+0.07925	−0.8403	+0.09431	.....	.....	.....	.....	− 11.195
6′	+1.0	−0.07925	−0.7250	+0.08137	.....	.....	.....	.....	0
a	.....	+0.92075	+0.8403	+0.09437	.....	.....	.....	.....	+ 127.038
b	.....	+1.07925	+0.7250	−0.08137	.....	.....	.....	.....	+ 115.843
a′	.....	+1.0	+0.9127	+0.10242	.....	.....	.....	.....	+ 137.980
b′	.....	+1.0	+0.6717	−0.07539	.....	.....	.....	.....	+ 107.335
c	.....	.....	+0.2410	+0.17781	.....	.....	.....	.....	+ 30.545
c′	.....	.....	+1.0	+0.7378	.....	.....	.....	.....	+ 126.730
3′	.....	.....	+1.0	+0.02428	−1.0	−0.02428	.....	.....	+ 33.712
7′	.....	.....	+1.0	−0.02428	−1.0	+0.02428	.....	.....	0
d	.....	.....	.....	+0. 7135	−1.0	+0.02428	.....	.....	+ 93.020
e	.....	.....	.....	+0.04856	.....	−0.04856	.....	.....	+ 33.712
d′	.....	.....	.....	+1.0	+1.4015	+0.03403	.....	.....	+ 130.37
e′	.....	.....	.....	+1.0	.....	−1.0	.....	.....	+ 694.30
f	.....	.....	.....	.....	+1.4015	+1.03403	.....	.....	− 563.93
f′	.....	.....	.....	.....	+1.0	+0. 7378	.....	.....	− 402.35
4′	.....	.....	.....	.....	+1.0	+0. 0014	− 1.6851	− 0.0008388	− 0.58
8′	.....	.....	.....	.....	+1.0	−0. 0014	− 1.9532	+ 0.0009723	0
g	.....	.....	.....	.....	.....	+0. 7364	+ 1.6851	+ 0.0008388	− 401.77
h	.....	.....	.....	.....	.....	+0. 0028	+ 0.2681	− 0.0018111	− 0.58
g′	.....	.....	.....	.....	.....	+1.0	+ 2.2883	+ 0.00114	− 545.60
h′	.....	.....	.....	.....	.....	+1.0	+94.83	− 0.64060	− 206.45
i	.....	.....	.....	.....	.....	.....	+92.54	− 0.64174	+ 339.15
i′	.....	.....	.....	.....	.....	.....	+ 1.0	− 0.006935	+ 3.665
5′	.....	.....	.....	.....	.....	.....	+ 1.0	+ 0.000039	+ 0.284
j	.....	.....	.....	.....	.....	.....	.....	+ 0.006974	− 3.949

process repeated. In line "j" of Table C, the value of C_8 is given in terms of known quantities, from which its value is readily determined. Then by substituting the value of C_8 in an equation in which C_7 is the only unknown, its value is also determined. Repeating the process, the value of all the constants are found to be as given below.

VALUES OF C

$C_1 = +\ 8.02$	$C_5 = -\ 0.74$
$C_2 = +\ 107.82$	$C_6 = -\ 544.35$
$C_3 = +\ 16.11$	$C_7 = -\ 0.262$
$C_4 = +\ 694.3$	$C_8 = -\ 566.3$

When the constants of integration are known the moment at the quarter point may be calculated for conditions at the end of section $A\ B$, or at the beginning of section $C\ D$ of Fig. 53.

For conditions at the end of section $A\ B$, the constants of integration to be used are C_1 and C_2. With these values given in Table C, and of e^{cx} and e^{-cx} as given in Table A, we find the moment at the quarter point to be

$$M_{\frac{1}{4}} = -\ 2{,}022{,}000[(8.02 \times 3.5522 + 107.82 \times 0.28151 - 115.843)]$$
$$= +\ 115{,}254{,}000 \text{ ft.-lbs.}$$

Comparing this result with that of the problem of Art. 227, we find that the effect of the variable moment of inertia is to reduce the moment by about 3.2 per cent. As the results obtained by the assumption of uniform moment of inertia are only slightly larger than those obtained by considering the moment of inertia variable, and also in view of the extra work of calculation involved, it is usually sufficiently accurate to consider the moment of inertia as uniform in calculating moments and shears.

230. Effect of Variable Hanger Pull on Value of H.—In the previous analysis for H it was assumed that the pull of the hangers (dead and live load) was uniform along the cable, and the work of displacement was found by multiplying this uniform pull by the deflection obtained from eq. (4). A more exact result will be obtained by using values of hanger pull obtained from eq. (8) of Art. 223. By taking points close together in the main and both side spans, the total external work may be found and equated to the internal work

as given by eq. (15) of Art. 225. The true value of H for any given loading condition is such that the expression for internal work in the cable, due to stress and temperature, and external work due to displacement, are equal to each other. The problem must then be solved by successive approximations.

The above method was applied to the determination of H for the structure of Art. 227, for a uniform live load of 4,000 lbs. per ft., extending from the left end of the main span to the quarter point, no load on the side spans, temperature 55° above normal.

As a first approximation, the value of H was taken as 663,400 lbs. as calculated for corresponding loading conditions in the problem of Art. 227. With this value of H, the hanger pull due to live load for the main and side spans was calculated from eq. (8) of Art. 223. For this purpose the main span was divided into sixteen parts and the side spans into eight, and values calculated for each point. The resulting values are given in the lower curve of Fig. 54 (*a*). The ordinates to this curve are measured from the line $A\ B$. In eq. (8), the values of the constants of integration, C_1 and C_2, for the loaded portion of the main span are given under Case I on Plate I. For the unloaded portion of the main span, the constants are given under Case III on Plate II, and for the side spans, the values are found under Case VII on Plate IV.

The average total hanger pull, due to dead and live load, which is to be used in calculating the work of displacement, is equal to one-half the live load hanger pull plus that due to dead load. The dead load hanger pull is equal to the weight of the truss per foot, which is given in the problem of Art. 227 as 5,820 and 6,130 lbs. per ft. for the main and side spans respectively. The resulting values are given in the upper curve of Fig. (*a*). The ordinates to this curve are also measured from the line $A\ B$.

The deflection at the various points was then calculated from eq. (4) of Art. 223. The constants of integration for the main and side spans are the same as for the hanger pull. The resulting deflections are plotted in the curve of Fig. (*b*). From the curve we see that the side-span deflection is upward, while that of the main span is downward.

The work of displacement is found by multiplying the average total hanger pull by the deflection at the same point. The resulting

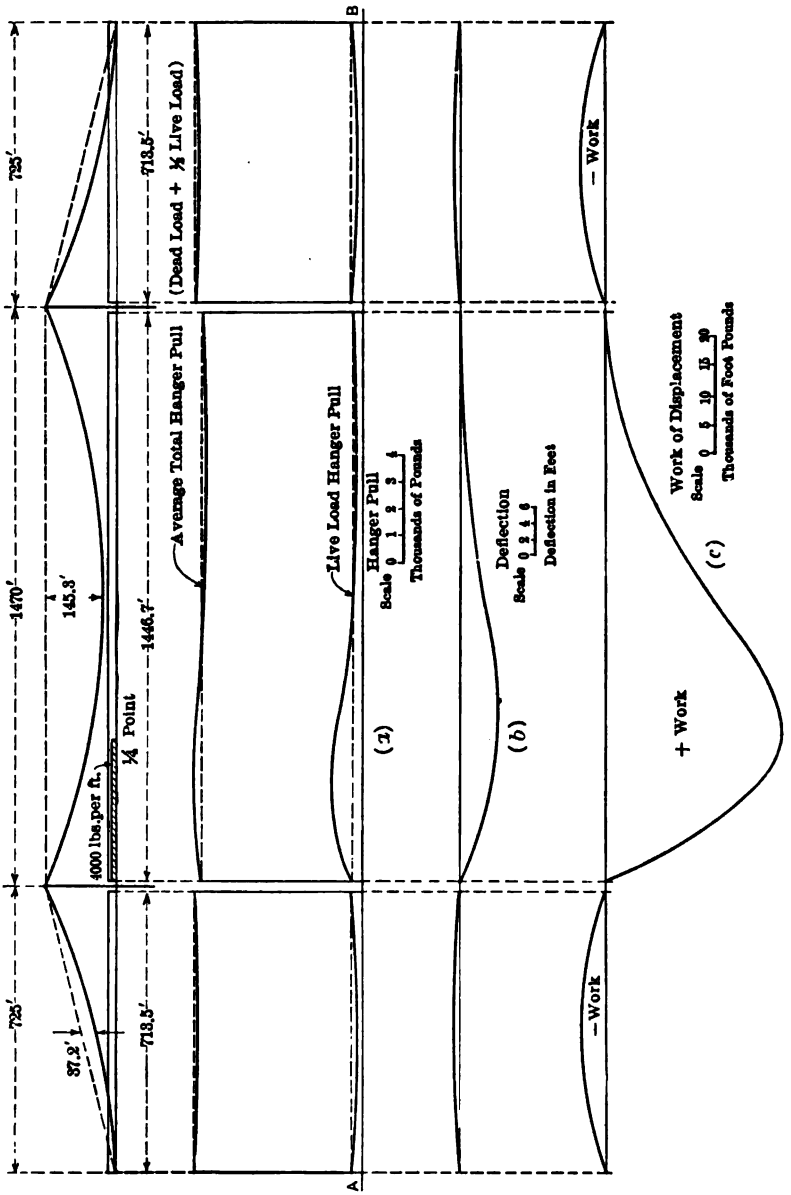
725'
1470'
725'
37.2'
145.3'
4000 lbs. per ft.
¼ Point
713.5'
1446.7'
713.5'
(Dead Load + ½ Live Load)
Average Total Hanger Pull
Live Load Hanger Pull
Hanger Pull
Scale 0 1 2 3 4
Thousands of Pounds
(a)
Deflection
Scale 0 2 4 6
Deflection in Feet
(b)
Work of Displacement
Scale 0 5 10 15 20
Thousands of Foot Pounds
(c)
+ Work
− Work
− Work
A
B

FIG. 54.

values are given in the curve of Fig. (*c*). The work in the main span is due to downward motion, or + work, and that in the side span is upward, or − work. In obtaining the total work we must then take the difference between the main and the side span quantities. These quantities are equal to the area of the corresponding diagrams.

The internal work in the cable, or that due to stress and temperature, is found by substituting in eq. (15) of Art. 225.

The values of the work in the various parts are given by the first set of quantities in the following table.

Work of Displacement:

	$H = 663{,}400$	$H = 673{,}400$
Main Span =	+ 20,300,400 ft.-lbs.	+ 19,805,800 ft.-lbs.
Side Spans =	− 3,608,100	− 3,643,700
Total	+ 16,692,300	+ 16,162,100

Internal Work:

Temperature	+ 13,049,400	+ 13,055,500
Stress	+ 3,104,600	+ 3,152,900
Total	+ 16,154,000	+ 16,208,400

Differences (Work of displacement − Internal work):

+ 528,100 ft.-lbs. − 46,300 ft.-lbs.

From the table we see that for $H = 663{,}400$, the work of displacement exceeds the internal work by 528,100 ft. lbs. This means that H, as assumed, was not correct, as the two values should be equal. A little study of the various equations will show that an increase in the value of H will cause a decrease in the total work of displacement and an increase in the internal work, thus tending to make the two results equal.

As a second approximation, the value of H was assumed to be 10,000 lbs. larger than before, or $H = 673{,}400$. The calculations were repeated and the results are shown by the second set of quantities in the above table. For this new value of H, the work of displacement is found to be − 46,300 ft. lbs., or less than the internal

work. Therefore, the true value of H is somewhere between $H = 663{,}400$ and $673{,}400$. Assuming that the variation in work between these two values follows a straight line law, we find by interpolation that the true value of H is 672,600 lbs., or a change of 9,200 lbs. from that computed in Art. 227, a difference of about 1.4 per cent.

The values of H, as computed from eq. (22), under the assumption of uniform hanger pull, and those computed by the above method for variable hanger pull, will be found to have their greatest difference for short loads on the main span. This is true since, for this loading, the value of H, and hence the hanger pull, is small, and any given variation appears as a large percentage of the average result. Thus in the case considered above, for $H = 673{,}400$ lbs., the hanger pull varies from 374 lbs. at the ends to a maximum of 1159.2 lbs. at the 3/16 point, and a minimum of 231 lbs. at the 3/4 point, values which are 310 per cent and 618 per cent respectively of the values of the ends. By the approximate method, the value of the hanger pull is given as $\frac{8fH}{l^2}$, which, for this case, is 374 lbs., or the value as above given for the ends.

When the span is fully loaded, or nearly so, the value of H, and hence also the hanger pull, will be large. Under such conditions the hanger pull will be practically uniform over the whole span. The values of H, as given by eq. (22), or by the method above, will then differ but slightly.

From the preceding discussion we see that the greatest error in the value of H, on the assumption of uniform hanger pull, occurs when only a small part of the structure is loaded. It will also be found that the value of H, calculated with the hanger pull assumed as variable, will be greater than for unifom hanger pull. The resulting moments and shears, calculated with this new value of H, will then be smaller than before, so that the error is on the side of safety.

Since the error involved in the assumption of uniform hanger pull is small in any case, the calculation may be carried out by the formulas of Arts. 223 and 226. The results will be well within the limits of accuracy obtainable with the assumed data as to normal temperature.

(*b*) *Structure with Truss Hinged at Centre*

231. Derivation of Formulas for Moments and Shears.—In a structure with a centre hinge, the advent of live load causes the cable to stretch, thus allowing the centre point to deflect a distance Δf. The effect of this centre deflection on a point distant x from the end of the span, Fig. 55, is to cause a deflection at this point of $\frac{2x}{l}\Delta f$. In addition to this deflection, the loads on the truss tend to cause an

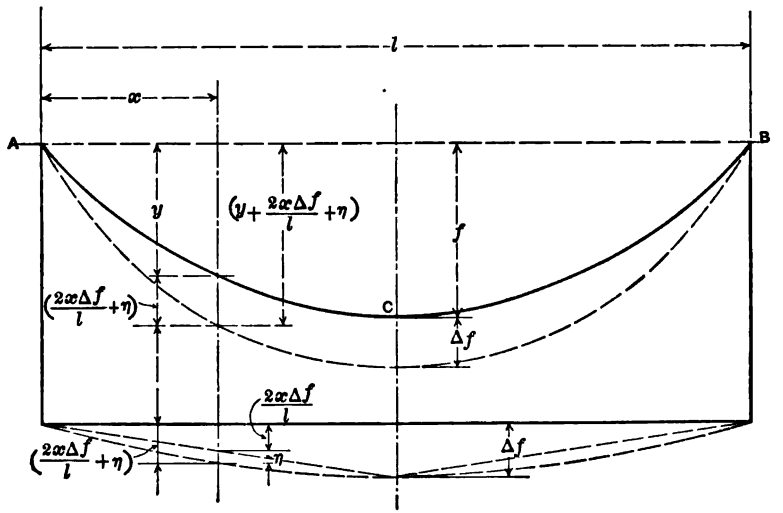

FIG. 55.

added deflection of η. The total deflection for any point is then $\eta + \frac{2x}{l}\Delta f$, the effect of the elongation of the hangers being neglected. The moment of the hanger loads is given by

$$(H + H_w)\left(y + \eta + \frac{2x\Delta f}{l}\right)$$

where H and H_w are the horizontal components of the cable stress due to live load and dead load respectively, for the cable in the de-

flected position. If $(H' + H'_w)$ is the value of the cable stress for the undeflected structure, we have

$$(H+H_w) = \frac{f}{(f+\Delta f)}(H' + H'_w)$$

The value of Δf to be used is found by successive approximations from Arts. 179 and 181. As the dead load is taken by the cable, the moment at any point in the stiffening truss is given by

$$M = M' - (H + H_w)\left(\eta + \frac{2x\Delta f}{l}\right) - Hy \quad . \quad (32)$$

Proceeding as in Art. 223, the differential equation of the deflection curve is found to be

$$\frac{d^2\eta}{dx^2} = c^2\left(\eta + \frac{2x\Delta f}{l}\right) - \frac{c^2}{(H+H_w)}M' + \frac{Hc^2}{(H+H_w)}y. \quad (33)$$

Integrating eq. (33), we have

$$\eta = \frac{H}{H+H_w}\left[C_1e^{cx}+C_2e^{-cx}+\frac{M'}{H}-\frac{2x\Delta fc^2EI}{Hl}-y+\frac{1}{c^2}\left(\frac{8f}{l^2}-\frac{p}{H}\right)\right] \quad (34)$$

which is the deflection at any point in the stiffening truss.

Substituting the value of η from eq. (34) in eq. (32), we have

$$M = -H\left[C_1e^{cx} + C_2e^{-cx} + \frac{1}{c^2}\left(\frac{8f}{l^2} - \frac{p}{H}\right)\right] \quad . \quad (35)$$

which is the moment at any point in the stiffening truss due to live load. It will be noted that this formula is identically the same as given in Art. 223. The values of the constants of integration C_1 and C_2, however, will be different from before. The conditions for the determination of these constants must include the condition that for $x = \frac{l}{2}$, $M = 0$. It will be found that the constants can be obtained in most cases from those of Art. 224, by replacing l by $\frac{l}{2}$ when l occurs as an exponent of e. Thus for full load conditions we find from eqs. (9) and (10)

$$C_1 = -\frac{1}{c^2}\left(\frac{8f}{l^2} - \frac{p}{H}\right)\frac{1}{(e^{\frac{1}{2}cl}+1)} \quad . \quad . \quad . \quad . \quad (36)$$

$$C_2 = C_1e^{\frac{1}{2}cl}. \quad . \quad . \quad . \quad . \quad . \quad . \quad . \quad . \quad . \quad (37)$$

The values of H to be used in the above equations may be taken from Art. 218 of the Approximate Method.

232. Effect of Temperature on Moments.—A change in temperature of t degrees will cause the cable to change its length an amount $\omega t L$. The change in sag Δf, due to this change in length is given by eq. (44) of Art. 181. These changes cause the centre point to deflect a distance Δf, thus inducing bending moments in the stiffening trusses similar in nature to those of Art. 231.

Let H' be the cable stress under dead load only, and H the value after the change in temperature takes place. Then

$$H = H' \frac{f}{f + \Delta f}$$

The moment in the stiffening truss due to the change in sag is

$$M = (H' - H)\, y - H \left(\frac{2x}{l} \Delta f + \eta\right)$$

or

$$M = H\left[\left(\frac{y}{f} - \frac{2x}{l}\right) \Delta f - \eta\right] \quad . \quad . \quad . \quad . \quad (38)$$

where the dimensions are as shown in Fig. 55. For a parabolic cable, where $y = \frac{4fx}{l^2}(l - x)$, eq. (38) reduces to the form

$$M = H\left[\frac{2x}{l^2}(l - x)\, \Delta f - \eta\right] \quad . \quad . \quad . \quad (39)$$

The differential equation of the deflection curve is given by

$$\frac{d^2\eta}{dx^2} = c^2 \eta - c^2 \frac{2x}{l^2}(l - 2x)\, \Delta f \quad . \quad . \quad . \quad (40)$$

where

$$c^2 - \frac{H}{EI} = \frac{H'}{EI} \frac{f}{(f + \Delta f)}$$

Integrating eq. (40) we have as the deflection at any point

$$\eta = C_1 e^{cx} + C_2 e^{-cx} + \frac{2x}{l^2}(l - 2x)\, \Delta f - \frac{8 \Delta f}{c^2 l^2} \quad . \quad (41)$$

Substituting the value of η as given by eq. (41) in eq. (39), we have

$$M = -H\left[C_1 e^{cx} + C_2 e^{-cx} - \frac{8 \Delta f}{c^2 l^2}\right] \quad . \quad . \quad (42)$$

which is the value of the moment at any point.

The constants of integration C_1 and C_2 may be determined from the conditions that for $x = 0$ and $x = \frac{l}{2}$, $M = 0$, from which we find

$$C_1 = \frac{8 \Delta f}{c^2 l^2 \left(1 + e^{\frac{cl}{2}}\right)} \quad . \quad . \quad . \quad . \quad . \quad . \quad . \quad (43)$$

$$C_2 = C_1 e^{\frac{cl}{2}} \quad . \quad . \quad . \quad . \quad . \quad . \quad . \quad . \quad . \quad (44)$$

Substituting these values in eq. (42), placing $H = c^2 E I$, we have

$$M_t = E I \frac{8 \Delta f}{l^2} \left[1 - \frac{e^{cx} + e^{\frac{c}{2}(l-2x)}}{1 + e^{\frac{cl}{2}}} \right] \quad . \quad . \quad (45)$$

which is the value of the moment at any point. By placing $\frac{d M_t}{d x} = 0$ in eq. (45), the maximum moment is found to occur at the quarter point. Substituting $x = \frac{l}{4}$ in eq. (45) the maximum moment is found to be

$$M_{t\,(max.)} = E I \frac{8 \Delta f}{l^2} \frac{\left(1 - e^{\frac{cl}{4}}\right)^2}{\left(1 + e^{\frac{cl}{2}}\right)} \quad . \quad . \quad . \quad . \quad (46)$$

This moment is positive for a rise in temperature and negative for a fall.

233. Example.—The moment at the quarter point due to stress and temperature will be worked out by the exact methods of Art. 231 and 232. The structure used will be the Manhattan Suspension Bridge, modified by placing a centre hinge in the main span, all other dimensions as given in Fig. 30 of Art. 205.

Value of Δf.—The value of Δf is found from the stretch of the cable due to the loading in question. For moment at the quarter point we find from eq. (105), Art. 219, that for $x = \frac{l}{4}$, $k = 0.4$. Then with $p = 4{,}000$ lbs. per ft., we have from eq. (98), of Art. 218,

$$H = \frac{p k^2 l^2}{4 f} = \frac{4{,}000 \times (0.4)^2 \times (1446.7)^2}{4 \times 145.3} = 2{,}304{,}700 \text{ lbs.}$$

The average stress in the cable is given by

$$T_{ave} = H\frac{\int ds}{\int dx} = H\frac{L}{l} = 2{,}304{,}700 \times \frac{1484.67}{1464.7} = 2{,}365{,}000 \text{ lbs.}$$

Here L is the length of the cable, which is given by eq. (21) of Art. 176, that is,

$$L = l\left(1 + \frac{8}{3}n^2 - \frac{32}{5}n^4 + \ldots\right) = 1484.67 \text{ ft.}$$

The extension of the cable due to the average cable stress is found to be

$$e = \frac{TL}{AE} = \frac{2{,}365{,}000 \times 1484.67}{275 \times 29{,}000{,}000} = 0.440 \text{ ft.}$$

where A = area of cable in sq. ins. = 275 sq. ins. From eq. (44) of Art. 181, the value of Δf is given by

$$\Delta f = \frac{15}{16}\frac{1}{(5n - 24n^3)}e = 0.864 \text{ ft.}$$

As this value is not exactly correct, since the cable stress changed with the increase in sag, the calculations must be repeated, using $(f + \Delta f)$, instead of f in the above equations. On the third such substitution the values obtained were $e = 0.438$ and $\Delta f = 0.855$, which will be taken as final.

Moment at Quarter Point.—The moment at the quarter point is given by eq. (35) of Art. 231, when $x = \frac{l}{4}$ or

$$M = -H\left[C_1 e^{\frac{cl}{4}} + C_2 e^{-\frac{cl}{4}} + \frac{1}{c_2}\left(\frac{8f}{l_2} - \frac{p}{H}\right)\right]$$

The constants of integration C_1 and C_2 are given by

$$C_1 = \frac{\frac{p}{2H_c^2}\left[e^{cl(\frac{1}{2}-k)} + e^{-cl(\frac{1}{2}-k)}\,2\,e^{-\frac{cl}{2}}\right] - \frac{8f}{c^2l^2}\left(1 - e^{-\frac{cl}{2}}\right)}{\left(e^{\frac{cl}{2}} - e^{-\frac{cl}{2}}\right)}$$

$$C_2 = -C_1 - \frac{1}{c^2}\left(\frac{8f}{l^2} - \frac{p}{H}\right)$$

In these equations the value of c is given by

$$c^2 = \frac{f}{(f + \Delta f)}\frac{(H + H_w)}{EI} = \frac{145{,}300}{(145{,}300 + 0.855)}\frac{(2{,}304{,}700 + 10{,}480{,}000)}{43900 \times 29{,}000{,}000}$$

$= c^2 = 0.000000983$, from which $c = 0.00316$.

Proceeding as in Art. 227, we find

$$e^{\frac{cl}{2}} = 9.831 \qquad e^{-\frac{cl}{2}} = 0.102 \qquad e^{\frac{cl}{4}} = 3.135 \qquad e^{-\frac{cl}{4}} = 0.319.$$
$$e^{cl(\frac{1}{2}-k)} = 1.579 \qquad e^{-cl(\frac{1}{2}-k)} = 0.633$$

The values of the constants of integration are found to be $C_1 = 12.921$, $C_2 = 106.331$. The moment at the quarter point becomes

$$M = -2{,}291{,}000\,[12.921 \times 3.135 + 106.331 \times 0.319 - 119.252] = +102{,}700{,}000 \text{ ft.-lbs.}$$

Comparing this value with the one given by the approximate method of Art. 220, we find a difference of 157,640,000 − 102,700,000 = 55,940,000 ft.-lbs., or more than 50 per cent in excess of the Exact Method result.

Moment Due to Temperature.—The moment at the quarter point due to temperature changes is given by eq. (46), of Art. 232.

$$M_t = E I \frac{8 \Delta f}{l^2} \frac{\left(1 - e^{\frac{cl}{4}}\right)^2}{\left(1 + e^{\frac{cl}{2}}\right)}$$

The value of Δf is calculated for the elongation of the cable due to the given changes in temperature. We then have $e = \omega t L$ where L is the length of the cable as calculated above, ω is the coefficient of expansion = 0.0000066, and $t = +55$ degrees. For these values,

$$e = 0.0000066 \times 55 \times 1484.67 = 0.5308 \text{ ft.}$$

Then as above

$$\Delta f = \frac{15}{16} \frac{1}{(5n - 24n^3)} e = 1.0413 \text{ ft.}$$

The final value of H_w in the deflected position is then

$$H_w = 10{,}480{,}000 \times \frac{145.3}{145.3 + 1.0413} = 10{,}405{,}400 \text{ lbs.}$$

where the change of temperature is considered as positive. The value of c is given by the equation

$$c^2 = \frac{H_w}{EI} = \frac{10{,}405{,}000}{43{,}900 \times 29{,}000{,}000} = 0.000008202$$

and $c = 0.002859$. With this value of c we have $e^{\frac{cl}{2}} = 7.908$ and $e^{\frac{cl}{4}} = 2.812$. Substituting these values in eq. (46), we find

$$M_t = +43{,}900 \times 29{,}000{,}000 \times \frac{8 \times 1.0413\,(-1.812)^2}{(1446.7)^2\, 8.908}$$
$$= +1{,}867{,}700 \text{ ft.-lbs.}$$

ERECTION ADJUSTMENTS

234. Height of Cable before Addition of Dead Load.—During the erection of a suspension bridge, the cable is placed in position before the addition of the dead load. It is then necessary to know the change in sag from the unloaded to loaded cable in order to determine the elevation of the unloaded cable. Let L_p = final loaded length of cable, hanging in a parabola with a centre sag f under dead load; L_c = unloaded length of cable, hanging in a catenary, and e_p = elongation of cable due to the application of the dead load of the trusses, $= L_p - L_c$.

Then $e_p = \frac{T L_c}{A E}$ where T = change in stress from unloaded to loaded condition; A = area of cable; E = coefficient of elasticity. The value of T to be used is the average for the whole cable, that is

$$T = H \frac{\int ds}{\int dx} = H \frac{L_p}{l} = \frac{w l^2}{8 f} \frac{L_p}{l}$$

w being the dead load of the trusses per unit of length and l the span length.

Since $L_c = L_p - e_p$ we have

$$e_p = \frac{H \frac{L_p}{l} (L_p - e_p)}{A E} = \frac{L_p}{\frac{l A E}{H L_p} - 1} \quad . \quad . \quad . \quad . \quad (47)$$

This value of e_p is only approximately correct, since the stress in the cable due to its own weight has changed during the elongation. In eq. (47) this increment of stress was not taken into account. Its effect on the value of e_p may be determined and applied to eq. (47) as a correction. For this purpose we can assume that the weight of the cable in its final position follows the parabolic law. Its stress in the final position is then

$$T_g = H \sec \alpha_{(ave.)} = H \frac{L_p}{l} = \frac{g l^2}{8 f} \frac{L_p}{l}$$

where g is the weight of the cable per unit length. Before the applica-

tion of the dead load of the trusses, the cable hung in a catenary, and its stress was

$$T_g = \frac{g}{c} \sec \alpha_{(ave.)} = \frac{g}{c} \frac{L_c}{l}, \text{ where } c = \frac{H}{g}.$$

The change in stress is then

$$d T_g = \frac{g}{l} \left(\frac{l^2}{8f} L_p - \frac{L_c}{c} \right).$$

The change in elongation due to this stress is given by

$$e_c = \frac{g}{l} \left(\frac{l^2}{8f} L_p - \frac{L_c}{c} \right) \frac{L_c}{A E} = \frac{g}{l} \left(\frac{l^2}{8f} L_p - \frac{L_c}{c} \right) \frac{(L_p - e_p)}{A E}. \quad (48)$$

Eq. (48) can be solved by successive approximation, making use of the equation for length of the catenary,

$$L_c = \frac{1}{c} \left(e^{\frac{cl}{2}} - e^{-\frac{cl}{2}} \right).$$

For the first approximation L_c may be taken as $(L_p - e_p)$. When the value of e_c has finally been obtained it can be applied to eq. (47) as a correction and the calculations repeated. Usually the second approximation will be final, as the quantities L_c and c of eq. (48) change only slightly for small changes in elongation. It is to be noted that the correction e_c will be negative, since the cable stress, and hence the elongation, decreases with increased sag.

235. Closure of Stiffening Trusses to Realize Normal Conditions.— In structures with horizontal stiffening trusses, the erection usually proceeds from the ends toward the centre, where the final closure is made. At the time of the closure the temperature conditions will not be equal to the normal conditions assumed in the calculations of stress, except in rare cases. Also the full dead load will usually not be in place, as the roadway paving, tracks, and side-walks are not placed in position until the riveting has been completed.

If the closure had been made at the assumed normal conditions, that is, full dead load and proper temperature, no stresses would exist in the stiffening truss at that time. But since this cannot be realized, the addition of dead load after closure, and changes in temperature,

will cause certain stresses to exist where the calculation assumed no stress. The effect of these changes in load and temperature on the final stresses, live load included, can be found in the following manner. Assume that the conditions at closure form a new set of normal conditions. Consider the dead load to be added as a uniform live load, and the difference between the temperature at closure and the assumed normal as the range in temperature. With these values calculate the bending moments in the truss. For this purpose we may use eqs. (4), (5), and (6) of Art. 223. The value of H is calculated for the dead load in place at closure, and the sag f is taken for the conditions existing at the same time.

When the moments thus induced are very large, due to the fact that the conditions at closure differ much from the normal, a correction may be applied by shortening or lengthening the hangers, which are usually adjustable. Knowing the bending moment existing as the assumed normal, due to changes in load and temperature, the deflection of the centre can be determined from eq. (4) of Art. 223. Then by changing the length of the centre hanger by this amount, and hangers at the other points as ordinates to a parabola, a negative, or opposite bending moment is set up, which, at assumed normal conditions, will reduce the stresses in the trusses to zero.

SECTION IV.—STRESSES IN LATERAL TRUSSES, TOWERS, AND FLOORBEAMS

236. Wind Stresses in Structures with Horizontal Stiffening Trusses.—The action of wind forces on the side of the stiffening truss causes the truss to deflect laterally as shown in Fig. 56. This lateral deflection is resisted by the lateral trusses and by the pull of the cables.

From Fig. (*d*), moments about any point, horizontal forces only being considered, we have

$$M = M' - (H + H_w)\,\eta + (H + H_w)\,(\eta - z) = M' - (H + H_w)z \quad . \quad (49)$$

From Fig. (*c*) we have $z = y\,\frac{\eta}{h}$, assuming that the hanger at any point forms a straight line from the truss to a line joining the tops of the towers. Substituting this value of z in eq. (49), we have

$$M = M' - (H + H_w)\frac{y\,\eta}{h} \quad . \quad . \quad . \quad . \quad (50)$$

In eq. (50) y is variable as well as η, and to reach an exact solution is difficult. However, as the cable effect is of greatest importance along the central portion where y is nearly equal to f, we may for

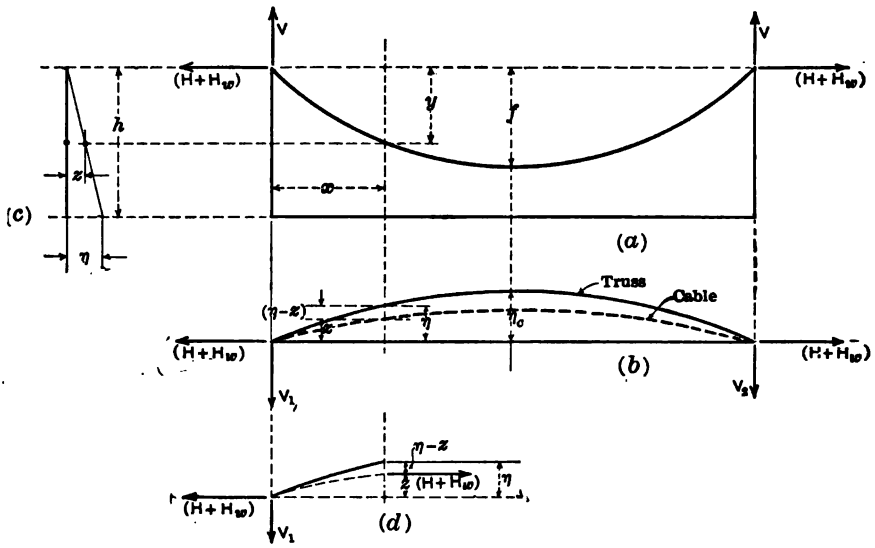

FIG. 56.

purposes of an approximate solution place $y = f$. The differential equation of the elastic curve of the truss is then given by

$$\frac{d^2\eta}{dx^2} = c^2\eta - \frac{M' h c^2}{f(H + H_w)} \quad . \quad . \quad . \quad . \quad (51)$$

where $c^2 = \frac{f}{h}\frac{(H + H_w)}{EI}$. Integrating eq. (51), we have

$$\eta = \frac{h}{f(H+H_w)}\left[C_1 e^{cx} + C_2 e^{-cx} + M' - \frac{p}{c^2}\right] \quad . \quad (52)$$

Substituting this value of η in eq. (50), the moment is given by

$$M = -\left[C_1 e^{cx} + C_2 e^{-cx} - \frac{p}{c^2}\right] \quad . \quad . \quad . \quad (53)$$

where p is the wind load per unit length.

The constants of integration in eq. (53) depend upon the loading conditions. It will be found that the moments are a maximum for a uniform wind load over the whole span.

For uniform load, the constants are determined from the condition that for $x = 0$ or $x = l$, $M = 0$. The values are then

$$C_1 = \frac{p}{c^2} \frac{1}{(e^{cl} + 1)} \quad . \quad . \quad . \quad . \quad . \quad (54)$$

$$C_2 = C_1 e^{cl} \quad . \quad . \quad . \quad . \quad . \quad . \quad . \quad . \quad (55)$$

Substituting the values of these constants in eq. (53), the moment at any point under full load is found to be

$$M = \frac{p}{c^2} \left[1 - \frac{e^{cx} + e^{c(l-x)}}{(e^{cl} + 1)} \right] \quad . \quad . \quad . \quad . \quad (56)$$

The moment is found to be a maximum at the centre, where the value is

$$M_c = \frac{p}{c^2} \left[\frac{\left(1 - e^{\frac{cl}{2}}\right)^2}{(e^{cl} + 1)} \right] \quad . \quad . \quad . \quad . \quad . \quad . \quad (57)$$

The shear at any point is found by taking the first derivative of eq. (53) with respect to x. We then have

$$V = -c[C_1 e^{cx} - C_2 e^{-cx}] \quad . \quad . \quad . \quad . \quad (58)$$

The constants of integration for any loading conditions are found by the same methods as given in Art. 224. It will be found that these constants can be obtained from those given on Plates I to IV by placing $f = 0$ and $H = 1$ in the corresponding case.

237. Wind Stresses in Other Types of Suspension Bridges.—In structures of the types shown in Figs. 14, 15, and 16, the wind bracing is usually placed in the plane of the cable. The floors are light platforms suspended from the cables, and any bracing placed therein is for the purpose of gaining rigidity under moving loads.

The arrangement of bracing in the plane of the cable varies with the type of the structure. In any case it will be very similar to that used in the arch structure of the same class.

The stresses in such bracing are calculated by the same methods as given for corresponding structures in Chap. IV.

238. Floorbeam Stresses.—In a suspension bridge with two cables, the stresses in the floorbeams are found in the same way as for a simple beam supported at two points. Where four cables are used, as in the Manhattan bridge, and the floorbeams are continuous, the analysis requires the consideration of the deflection of the cables

and the continuity of the beams. Fig. 57 shows the arrangement used in the Manhattan Bridge.

When all tracks, roadways, and side-walks are fully loaded, the cables will deflect equal distances and the reactions of the floorbeam will be equal.

Under unsymmetrical loading the cables will receive varying proportions of the load, thus causing unequal deflections of the various

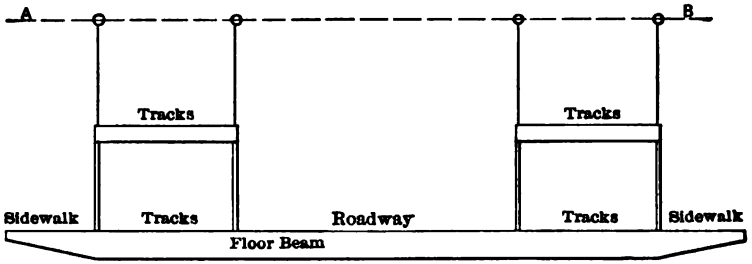

(*a*)

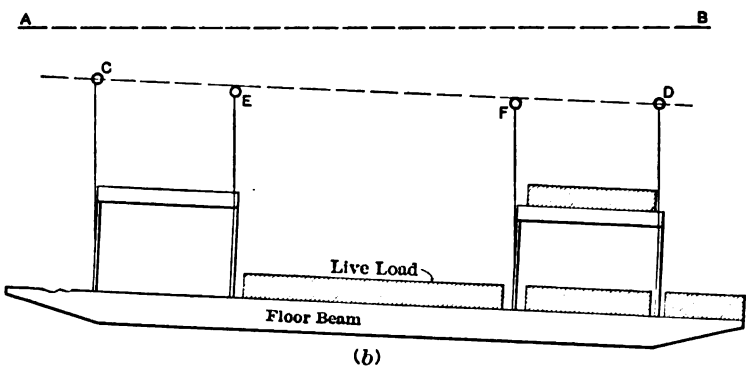

(*b*)

FIG. 57.

cables and also of the points of support of the floorbeams. The beams are then continuous on four supports which do not lie in the same straight line. The maximum bending moments in the floorbeams will be found to occur for the loading which will cause the greatest difference in deflection of the cables. This loading is shown in Fig. 60 (*b*), the tracks and sidewalks on one side and the roadway being fully loaded over the entire length of the structure. The load taken by cable *C* is then transmitted entirely by the bending of the floorbeams.

In determining the stresses in the floorbeams for the loading conditions given above, it is sufficiently exact to assume the loads on the cables to be proportional to their deflection; and, as these deflections are large compared with that of the floorbeam, the deformations of the beam may be neglected. The reactions may then be found in the same manner as the fibre stress in a beam subjected to direct compression as well as moment. If P = total live load per panel, e = eccentricity, R = any of the four cable reactions, and a = distance of such cable from the axis, we have $R = \frac{P}{4} \pm \frac{P\,e\,a}{\Sigma\,a^2}$. Here the term $\Sigma\,a^2$ replaces the moment of inertia of the usual beam formula. With these reactions, the bending moments and shears are readily calculated by the usual methods.

239. Tower Stresses.—When the saddles are rigidly fastened to the tops of the towers, as in the Manhattan Suspension Bridge, the

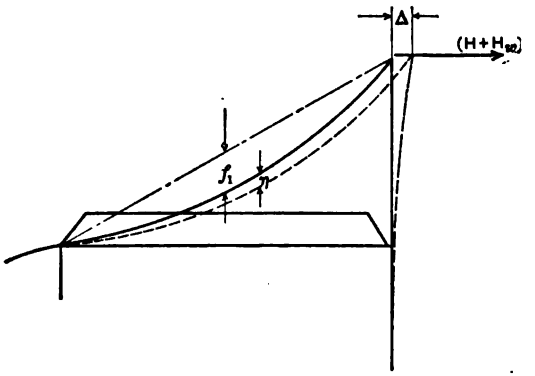

FIG. 58.

movement of the saddles due to changes in loading or temperature conditions will cause bending stresses to be set up in the towers. As this deflection must take place, the bending stresses induced will be proportional to the stiffness of the tower.

The deflection may be determined by the approximate method given in Art. 204, or by a more exact method in which work done by external and internal forces during the deflection are placed equal to zero.

In Fig. 58, let Δ be the deflection of the tower, and $(H + H_w)$ the cable stress for any given loading conditions. Then the average

work done by the force $(H + H_w)$ moving through the distance Δ must be equal to the average work in the cable due to stress and temperature, and the work done in the deflection of the side span. The average work done by the force $(H + H_w)$ is given by $\left(\frac{H}{2} + H_w\right)\Delta$. From Art. 225, the average work in the cable due to stress and temperature is respectively $\left(\frac{H}{2} + H_w\right)\int_0^{l_1} \frac{d\,s^3}{d\,x^2}$ and $\left(\frac{H}{2} + H_w\right)\int_0^{l_1} \omega t \frac{d\,s^2}{d\,x^2}$. The average work done in the deflection of the side span is given by $\left(\frac{H}{2} + H_w\right)\frac{8\,f_1}{l_1^2}\int_0^{l_1} \eta_1\,d\,x$ where η_1 is found from eq. (4) of Art. 223. Neglecting the work done in bending the tower, we have

$$\left(\frac{H}{2} + H_w\right)\Delta = \left(\frac{H}{2} + H_w\right)\frac{H}{A\,E} I_s + \left(\frac{H}{2} + H_w\right)\omega\, t\, L_t + \frac{8\,f_1}{l_1^2}\int_0^{l_1} \eta_1\,d\,x \quad . \quad (59)$$

where L_s and L_t represent the value of $\int_0^{l_1} \frac{d\,s^3}{d\,x^2}$ and $\int_0^{l_1} \frac{d\,s^2}{d\,x}$ respectively for the side spans only. Then from eq. (59),

$$\Delta = \frac{H}{A\,E} L_s + \omega\, t\, L_t + \frac{8\,f_1}{l_1^2}\int_0^{l_1} \eta_1\,d\,x \quad . \quad . \quad . \quad (60)$$

The greatest deflection will occur when the main and far side spans are fully loaded, no load on the side span in question, temperature lowest.

Substituting the value of η for this condition of loading, the maximum deflection is found to be

$$\Delta = \frac{H}{AE} L_s + \omega t L_t + \frac{H}{(H + H_w)}\left[\frac{16 f_1}{c_1^3 l_1^2}\frac{(e^{c_1 l_1} - 1)}{(e^{c_1 l_1} + 1)} - \frac{8 f_1}{c_1^2 l_1} + \frac{2}{3} f_1 l_1\right]\frac{8 f_1}{l_1^2} \quad (61)$$

The bending stresses in the tower are due to a horizontal load Q and a vertical load V as shown in Fig. 59 (a).

The load Q is such that if applied at the top of the tower, it would (together with V) cause a deflection equal to Δ of eq. (61). The load V is equal to the sum of the vertical components of the cable

stress acting on the tower, as shown in Fig. 59 (*b*). The amount of this force is given by

$$(H + H_w)\,[\tan\alpha + \tan\alpha_1 + \Delta\tan\alpha + \Delta\tan\alpha_1]$$

where $\Delta\tan\alpha$ and $\Delta\tan\alpha_1$ are the changes in $\tan\alpha$ and $\tan\alpha_1$ due to the deflection of the main and side spans. From eq. (4) of Art. 223, $\Delta\tan\alpha = \dfrac{d\eta}{dx}$. The loads V_1 and V_2 are the end reactions of the main and side spans.

The amount of the load Q may be determined by placing the deflection of the top of the tower, as given by the equation of the elastic

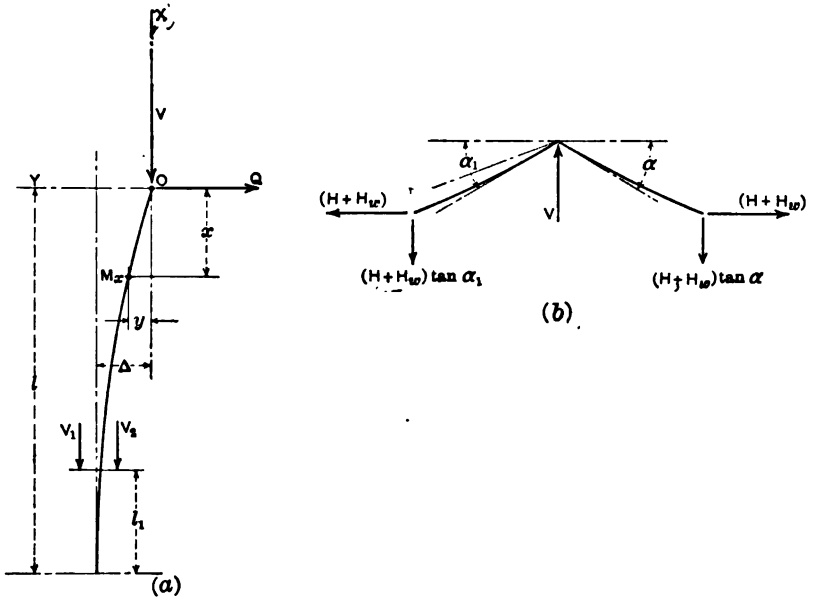

FIG. 59.

curve, equal to Δ as given by eq. (61). As Q is the only unknown, its value is readily determined. From Fig. 59 (*a*) the bending moment at any point in the tower, neglecting the effect of the loads V_1 and V_2, is given by

$$M_x = V\,y + Q\,x \quad . \quad . \quad . \quad . \quad . \quad . \quad (62)$$

The differential equation of the elastic curve is

$$\frac{d^2y}{dx^2} + c^2\,y = -\frac{Qc^2}{V}\,x \quad . \quad . \quad . \quad . \quad . \quad (63)$$

where $c^2 = \frac{V}{EI}$. Integrating eq. (63) we have

$$y = A \sin c\,x + B \cos c\,x - \frac{Q}{V} x \quad . \quad . \quad . \quad (64)$$

where A and B are constants of integration.

If the moment of inertia of the tower is uniform over its whole length, the values of A and B are determined from the two conditions that for $x = 0$, $y = 0$ and $x = l$, $y = \Delta$, from which

$$A = \left(\frac{Q\,l}{V} + \Delta\right) \text{cosec. } c\,l \text{ and } B = 0$$

Eq. (64) then becomes

$$y = \left(\frac{Q\,l}{V} + \Delta\right)\frac{\sin\ c\,x}{\sin\ c\,l} - \frac{Q}{V} x \quad . \quad . \quad . \quad . \quad (65)$$

The values of Q and Δ are found from eq. (65) for the condition that $\frac{dy}{dx} = 0$ when $x = l$.

We then have

$$\Delta = \frac{Q}{Vc} (\tan c\,l - c\,l)$$

and

$$Q = \frac{V\,\Delta\,c}{(\tan c\,l - c\,l)} \quad . \quad . \quad . \quad . \quad . \quad . \quad (66)$$

where Δ is given by eq. (61).

Substituting the value of y from eq. (64) in eq. (62), the moment at any point is found to be

$$M_x = (Q\,l + V\,\Delta) \frac{\sin\ c\,x}{\sin\ c\,l} \quad . \quad . \quad . \quad . \quad (67)$$

For $x = 0$, or at the top of the tower, $M = 0$; and for $x = l$, or at the foot of the tower, $M = (Q\,l + V\,\Delta)$.

As actually constructed, the sections in such towers are made to fit the stresses, so that the moment of inertia is not uniform. In such cases the deflections and moments are determined by a method similar to that used in Art. 229. The tower is divided into lengths over which the moment of inertia may be taken as uniform. Then by placing the moment and shear at the end of one section equal to that at the beginning of the next, a sufficient number of independent equations

are obtained for the determination of the constants of integration. For this purpose the moment at any point, from eqs. (62) and (64), is given by

$$M_x = V\,(A \sin c\,x + B \cos c\,x).$$

The shear at any point is

$$\frac{d\,M_x}{dx} = c\,V\,(A \cos c\,x - B \sin .\, c\,x).$$

The deflection at any point is given by substituting the constants of integration for the section in question, as determined above, in eq. (64).

SECTION V.—STRUCTURES WITH SUSPENSION FRAMES

240. Suspension Bridges with Three Hinges.—The structure shown in Fig. 16 of Art. 185 is similar in nature to a three-hinged arch. The stresses are all statically determinate and may be found by the methods given in Chap. IV. Structures of this type are usually made rigid enough so that the effect of deflection may be neglected.

If the points in the lower chord of the structures shown in Fig. 16 lie in a curve corresponding to the equilibrium polygon for dead or full live load, the stresses in the top chord and the web members will be zero for such loading conditions. The top chord and the web members will then be stressed by unsymmetrical loads only. Under unsymmetrical loading the equilibrium polygon will no longer coincide with the bottom chord member. When the equilibrium polygon falls below the bottom chord member, the stress in this member will be compression, and that in the top chord member will be tension. When the equilibrium polygon falls between the two chords, both will be in tension. Thus in such a structure the top chord stresses will always be tension, while those in the bottom chord may be either tension or compression.

In some cases, the curve of the bottom chord is made such that the equilibrium polygon will fall near the centre of the truss, or inside the middle third under all conditions of loading. Under such conditions the stresses in both chords will always be tension.

Structures of this type are also constructed with side spans. Such

a structure is shown in Fig. 60. This structure is similar in form to that of Fig. 15, Art. 185, except that a hinge has been placed in the centre of the top chord in the main span, and the lower chord members in the centre panel have been removed. The stresses in the main span trusses are found as given above. In the side spans, the stresses are found as for a simple span of the same length. The top chord member, however, acts as a back stay for the main span. The greatest tension in this top chord member occurs when the main

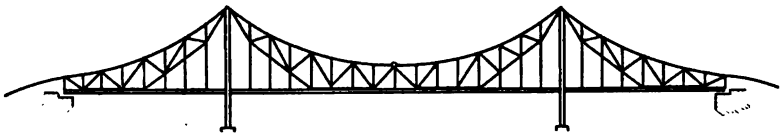

FIG. 60.

span and the far side span are loaded; no load on the side span in question. The greatest compression occurs when the side span in question is loaded, no load on the rest of the structure.

Temperature stresses in structures of this class are usually neglected. The deflections and bending moments resulting from temperature changes may be found by methods similar to those used in Art. 232.

241. Suspension Bridges with Two Hinges.—In a structure of the type shown in Fig. 64, the main and side spans form a group of trusses,

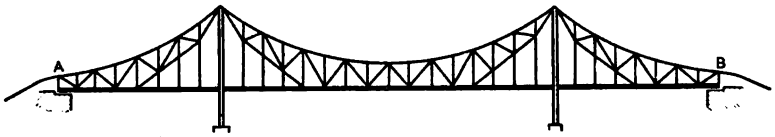

FIG. 61.

each one of which acts as a two-hinged arch, the horizontal component being taken by the anchorage.

The stresses in the members of this system may be determined by placing the movement of points A and B, Fig. 61, due to any given loading, equal to the extension of the anchorage for the same loading. In making up the expression for deflection the stresses in the various members must be expressed in terms of H, the horizontal component of the stress in the anchorage, which is equivalent to considering this as the redundant force.

Let the stress in any member of the combined system of trusses be given by $(S' + H u)$, where S' is the stress in the member in question for the truss considered as acting alone; H is the horizontal component of the stress in the anchorage; and u is the stress in the member for a 1 lb. load at A and B acting outward. Then the general expression for deflection is

$$D = \Sigma \frac{S u l}{A E} = \Sigma \frac{(S' + H u) u l}{A E}$$

Where l is the length of any member and A its area. Let S' and u as defined above represent main span values, and let S'_1 and u_1, S'_2 and u_2, represent side span values. The total deflection at A or B is then

$$D = \Sigma \frac{(S' + H u) u l}{A E} + \Sigma \frac{(S'_1 + H u_1) u_1 l_1}{A_1 E} + \Sigma \frac{(S'_2 + H u_2) u_2 l_2}{A_2 E}$$

The extension of the two anchorages is given by $\Delta L = \frac{2 H l}{A E}$, where l is the length and A the area of the member. Placing $D = \Delta L$ and solving for H, we have

$$H = \frac{\Sigma \frac{S u l}{A E} + \Sigma \frac{S_1 u_1 l_1}{A_1 E} + \Sigma \frac{S_2 u_2 l_2}{A_2 E} + \Delta L}{\Sigma \frac{u^2 l}{A E} + \Sigma \frac{u_1^2 l_1}{A_1 E} + \Sigma \frac{u_2^2 l_2}{A_2 E}} \quad . \quad . \quad (68)$$

which is horizontal component of the stress in the anchorage.

After this stress has been determined, the stresses in the various members are obtained by the methods given in Chap. IV.

242. Suspension Bridges with Stiffened Cables which are Continuous from Anchorage to Anchorage.—In structures of this type the methods of calculation are similar to those given for Hingeless Arches in Chap. IV. The stresses in the members are threefold indeterminate due to the fact that the cables form a rigid system which is continuous over the towers and the main span. Such a structure is shown in Fig. 14. The stresses may be found by the method of redundant members by considering three members as redundant. Those usually chosen are the members at the tops of each tower and the one in the centre panel of the main span.

CHAPTER VI

MISCELLANEOUS PROBLEMS IN STATICALLY INDETERMINATE STRUCTURES

SECTION I.—MULTIPLE INTERSECTION TRUSSES

243. General Formulas.—In Chapter VII of Part I, the general method of analyzing structures with redundant members was given and briefly illustrated. In the preceding chapters of this Part several special cases have been considered. There remain numerous other problems of statically indeterminate structures arising in practice which merit attention, but before taking these up in detail the method explained in Part I will be restated and the equations presented in a somewhat more general form.

Consider a structure containing any number of redundant members and supporting certain loads applied at joints only. Assume, first, that all members are subjected to direct stress only (no members acting as beams).

Let n = number of necessary members;

m = number of redundant members;

S = stress in any one of the n necessary members, due to the given loads;

S_1, S_2, S_3, etc., = stresses in the several redundant members due to the given loads (the stresses S, S_1, S_2, etc., occur simultaneously);

S' = stress in any one of the n necessary members due to the external loads, with all redundant members removed;

u_1 = stress in any of the n members due to a one-pound tension in redundant member No. 1, all other redundant members being removed; u_2 = stress for a one-pound tension in No. 2; etc., etc.;

E, A and l = modulus of elasticity, area of cross-section, and length of any member.

Then for any member

$$S = S' + u_1 S_1 + u_2 S_2 + u_3 S_3 + \text{etc.} \quad . \quad . \quad . \quad (1)$$

Now, as in Art. 222 of Part I, we assume each of the redundant members in turn cut near one end, and place equal to zero the deflection of the cut end with respect to the adjacent joint. This deflection is expressed in terms of the deformations of the n necessary members and the redundant member in question. We thus have the general equations

$$\left.\begin{aligned} \Sigma_{o}^{n}\frac{S u_1 l}{E A} + \frac{S_1 l_1}{E A_1} &= o \\ \Sigma_{o}^{n}\frac{S u_2 l}{E A} + \frac{S_2 l_2}{E A_2} &= o \\ \Sigma_{o}^{n}\frac{S u_3 l}{E A} + \frac{S_3 l_3}{E A_3} &= o \\ \text{etc.} \qquad\qquad \text{etc.} & \end{aligned}\right\} \quad . \quad . \quad . \quad . \quad . \quad . \quad (2)$$

Substituting the value of S from eq. (1) we have the following series of equations between the several redundant stresses and the stresses S':

$$\left.\begin{aligned} S_1\left(\frac{l_1}{E A_1}+\Sigma\frac{u_1^2 l}{E A}\right)+S_2\,\Sigma\frac{u_1 u_2 l}{E A}+S_3\,\Sigma\frac{u_1 u_3 l}{E A}+\ldots\text{etc.} &= -\Sigma\frac{S' u_1 l}{E A} \\ S_1\Sigma\frac{u_2 u_1 l}{E A}+S_2\left(\frac{l_2}{E A_2}+\Sigma\frac{u_2^2 l}{E A}\right)+S_3\,\Sigma\frac{u_2 u_3 l}{E A}+\ldots\text{etc.} &= -\Sigma\frac{S' u_2 l}{E A} \\ S_1\Sigma\frac{u_3 u_1 l}{E A}+S_2\,\Sigma\frac{u_3 u_2 l}{E A}+S_3\left(\frac{l_3}{E A_3}+\Sigma\frac{u_3^2 l}{E A}\right)+\ldots\text{etc.} &= -\Sigma\frac{S' u_3 l}{E A} \\ \text{etc.} \qquad\qquad \text{etc.} \qquad\qquad \text{etc.} & \end{aligned}\right\} \quad . \quad (3)$$

In these equations the summation in all cases extends over the n necessary members only, as no other member has a stress u. If we consider that the u for the redundant member in question is unity, then the two terms in the parentheses may in general be represented by the single summation $\Sigma\,\frac{u^2 l}{E A}$.

In this manner as many equations may be written as there are redundant members. The numerical values of the coefficients of S_1, S_2, S_3, etc., and of the second members of the equations, are readily calculated and the resulting linear equations may then be solved for S_1, S_2, etc. The value of any stress S is then found from eq. (1). It is well to note that the several coefficients of S_1, S_2, etc., of eq. (3) contain products of u which are, in each equation, the product of a

particular u times each of the other u's in succession, the latter corresponding to the S of the same term.

As already illustrated by the analysis of Art. 166, the displacement diagram may be used advantageously in calculating the various summations in eq. (3). For this purpose all redundant members are to be considered as cut near one end. A displacement diagram is then drawn for a one-pound load applied at the cut ends of No. 1, no external loads acting; another diagram for a one-pound load at the ends of No. 2, etc.; one diagram being drawn for each member. Finally, a like diagram is drawn for the external loads, involving the stresses S'. It will then be found that all the coefficients of S_1, S_2, etc., of the first of equations (3), are given by the first diagram; those of the second equation by the second diagram, etc.; and all the summations of the second members of the equations are given by the last diagram mentioned. Or, in detail, considering the first diagram, the quantity $\left(\frac{l_1}{EA_1} + \Sigma \frac{u_1^2 l}{EA}\right)$ is the relative displacement of the cut ends of redundant member No. 1; the quantity $\Sigma \frac{u_1 u_2 l}{EA}$ is the relative displacement of the cut ends of No. 2, etc. In the diagram constructed for the external loads, $\Sigma \frac{S' u_1 l}{EA}$ is the relative displacement of the cut ends of No. 1, etc. It will be noted that $\Sigma \frac{u_1 u_2 l}{EA}$ is given in both the first and second diagrams, and $\Sigma \frac{u_1 u_3 l}{EA}$ in both the first and third diagrams, etc. The utilization of this principle (of reciprocal deflections) will make it necessary to construct but a portion of the displacement diagrams of the second and succeeding members.

In case the structure includes members acting as beams then the expressions for deflection include terms of the form $\int \frac{M\,dx}{EI} \cdot m$. If the redundant members themselves are subjected to direct stresses only, then eq. (2) takes the form

$$\Sigma_0^n \frac{S u_1 l}{EA} + \Sigma_0^n \int \frac{M\,dx}{EI} \cdot m_1 + \frac{S_1 l_1}{EA_1} = 0 \quad . \quad . \quad . \quad (4)$$

in which M = bending moment in any member under normal conditions, and m_1 = bending moment due to a one-pound tension in redundant member No. 1. In the same manner as S is expressed in eq. (1) we may write $M = M' + S_1 m_1 + S_2 m_2 + \ldots$, etc. The values of S and M being substituted, gives a series of linear equations similar to (3), as follows:

$$S_1\left(\frac{l_1}{EA_1} + \Sigma\frac{u_1^2 l}{EA} + \Sigma\int\frac{m_1^2 dx}{EI}\right) + S_2\left(\Sigma\frac{u_1 u_2 l}{EA} + \Sigma\int\frac{m_1 m_2 dx}{EI}\right)$$
$$+ S_3\left(\Sigma\frac{u_1 u_3 l}{EA} + \Sigma\int\frac{m_1 m_2 dx}{EI}\right) + \ldots \text{etc.}, = -\Sigma\frac{S' u_1 l}{EA} - \Sigma\int\frac{M' m_1 dx}{EI} \quad (5)$$
$$\text{etc.} \qquad \text{etc.} \qquad \text{etc.}$$

Instead of assuming as the unknowns the various direct stresses S_1, S_2, etc., it is sometimes more convenient to take certain of the bending moments as the unknowns, or certain direct stresses together with certain moments. In this case the values u_1 and m_1, corresponding to an unknown bending moment M_1, are respectively the stresses and moments in the various members due to a bending moment of unity in the redundant member. The resulting equations are then the same as (5) excepting that certain unknown moments, M_1, M_2, etc., are used instead of the stresses S_1, S_2, etc.

244. *Equations Derived from the Principle of Least Work.*—The entire internal work of displacement of a structure is given by the expression

$$\text{Work} = \Sigma\frac{S^2 l}{2EA} + \Sigma\int\frac{M^2 dx}{2EI}. \quad . \quad . \quad . \quad . \quad (6)$$

If the structure contains various redundant stresses S_1, S_2, etc., or moments M_1, M_2, etc., the first derivative of the expression for work may be written with respect to each of the unknowns in turn, as explained in Part I, Art. 213, and each of these expressions placed equal to zero. This gives us, for member No. 1,

$$\Sigma\frac{Sl}{EA}\cdot\frac{dS}{dS_1} + \Sigma\int\frac{M\,dx}{EI}\cdot\frac{dM}{dS_1} = 0. \quad . \quad . \quad . \quad (7)$$

But in general $\frac{dS}{dS_1} = u_1$ and $\frac{dM}{dS_1} = m_1$, as here defined. Furthermore, in (7) the expression $\Sigma\frac{Sl}{EA}\cdot\frac{dS}{dS_1}$ includes also member No. 1, in which $\frac{dS}{dS_1} = 1$, hence (7) is identical with (4).

With respect to any unknown moment M_1 the derivative is

$$\Sigma \frac{S l}{E A} \cdot \frac{dS}{dM_1} + \Sigma \int \frac{M\,dx}{E I} \cdot \frac{dM}{dM_1} = 0 \quad . \quad . \quad . \quad (8)$$

in which $\frac{dS}{dM_1}$ and $\frac{dM}{dM_1}$ is the stress or moment in any member due to a unit bending moment in the redundant member. These quantities may be called u_1 and m_1 as before. The physical interpretation of eq. (8) is that the relative angular change in the two cut ends of the redundant member is zero, corresponding to the longitudinal movement in the case of redundant direct stresses.

245. Forms of Trusses and Methods of Analysis.—The most common types of multiple intersection trusses are the double Warren or triangle truss and the Whipple or double intersection Pratt truss. These forms have been fully treated in Part I by the usual approximate methods, based on the assumption of independent action of the two web systems. This same method of treatment may be applied to triple and higher forms of multiple trusses with generally satisfactory results.

Where the several systems are connected at points other than at supports, as when inclined end-posts are used, some ambiguity arises in the usual approximate treatment (see Art. 101, Part I). Uncertainty of procedure also arises in the case of an odd number of panels or an otherwise unsymmetrical system. In the case of curved chords, also, the web systems cannot act independently to so great an extent as with horizontal chords. In certain other multiple forms it is difficult or impossible to separate the structure into two or more single systems so as to arrive at any satisfactory solution by approximate methods.

It is the purpose of the following articles to explain more fully than was done in Part I, the use of exact methods of calculation and to illustrate by examples the errors involved in certain cases by the application of the usual approximate methods.

246. The Double Triangular Truss with Vertical End-Posts.—The results given in the example of Art. 222, Part I, showed that the usual assumption of independent action of the two web systems gives correct results for the chord stresses under uniform loads, and that the maximum error in web stress when calculated on this basis was, in the

truss in question, only 5 per cent, and this for the web member nearest the centre. For all other web members the error was too small to be noted. In the case of an eight-panel truss of similar form, analyzed by Winkler,* the corresponding errors in the web stresses ranged from 0 to 1 per cent from end toward centre. The first counter-stress

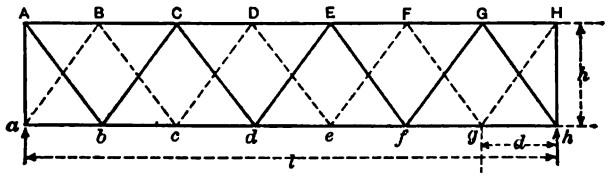

FIG. 1.

showed an error of 1.1 per cent and the second counter-stress an error of 4 per cent.

From these and other examples it may be concluded that in the form here considered, the number of panels being even, the results by the approximate method are well within the desired limit of accuracy.

247. *Double Triangular Truss With Odd Number of Panels.*— When the number of panels is odd then the symmetry of the systems is interrupted and their independence of action is more in question.

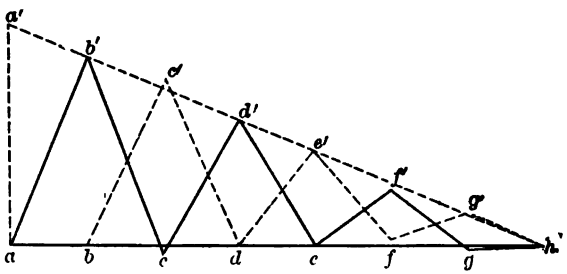

FIG. 2.

A peculiar condition arises in such systems when the structure is fully loaded. In the truss of Fig. 1, for example, under full uniform load, there is no shear in the panel *d e* and hence, apparently, no diagonals need be stressed in this panel. It is obvious that any stress which may exist in one of the diagonals is opposed by an equal stress in the

* "Theorie der Brücken," II Heft.

other. Assuming independent systems, however, there will be a tension in each diagonal of $\frac{2}{7}P$, if a through bridge, and an equal compression, if a deck bridge, where P = joint load. It is sometimes assumed that under a uniform load, since there is no shear in the central panel, neither of the members dE or De are stressed, and that the two web systems break up into a different arrangement from that existing under an unsymmetrical load.

The maximum stresses calculated under the two different assumptions differ considerably. Thus, assuming independent systems, and all joints loaded, we have

$$\text{Vert. comp. } aB = \frac{9}{7}P$$

$$\text{Vert. comp. } Ab = \frac{12}{7}P$$

whereas, with members De and dE out of action, the values are $\frac{7}{7}P$ and $\frac{14}{7}P$ respectively, a difference of $\frac{2}{7}P$. Then in the chord members the assumption of independent systems gives stresses as follows (d = panel length, h = height):

$$DE = \frac{44\,d}{7\,h}P; \qquad de = \frac{40\,d}{7\,h}P;$$

$$CD = \frac{40\,d}{7\,h}P; \qquad cd = \frac{37\,d}{7\,h}P.$$

The assumption of zero stress in the members De and dE gives

$$CD = DE = de = \frac{42\,d}{7\,h}P;$$

$$cd = \frac{35\,d}{7\,h}P.$$

It will be found that, in general, the stresses in each diagonal under full load, obtained by the two different methods, differ by $\frac{2}{7}P$, and the stresses in each chord member differ by $\frac{2\,d}{7\,h}P$.

To determine the correct distribution of stress, and to illustrate further the analysis of multiple intersection trusses, an exact analysis

will be made of the seven-panel truss of Fig. 1. Span = 7x24 = 168 ft.; height = 32 ft. The member $A\,a$ is taken as the redundant member and its stress for a concentrated load at each of the joints g, f, and e is determined. To simplify the numerical work each joint load is

Member	A	u	$\frac{u\,l}{A}$	$\frac{u^2\,l}{A}$	Load at g		Load at f		Load at e	
					S'	$\frac{S'\,u\,l}{A}$	S'	$\frac{S'\,u\,l}{A}$	S'	$\frac{S'\,u\,l}{A}$
$A\,a$	22	+1.00	+.182	.182						
$A\,b$	25	−1.25	−.250	.312	0	0	0	0	0	0
$a\,B$	25	−1.25	−.250	.312	−1.25	+ .31	−2.50	+ .62	−3.75	+ .93
$B\,c$	20	+1.25	+.312	.390	+1.25	+ .39	+2.50	+ .78	+3.75	+1.17
$b\,C$	20	+1.25	+.312	.390	0	0	0	0	0	0
$C\,d$	14	−1.25	−.446	.558	0	0	0	0	0	0
$c\,D$	14	−1.25	−.446	.558	−1.25	+ .56	−2.50	+1.12	−3.75	+1.67
$D\,e$	12	+1.25	+.521	.652	+1.25	+ .65	+2.50	+1.30	+3.75	+1.95
$d\,E$	12	+1.25	+.521	.652	0	0	0	0	0	0
$E\,f$	14	−1.25	−.446	.558	0	0	0	0	0	0
$e\,F$	14	−1.25	−.446	.558	−1.25	+ .56	−2.50	+1.12	+5.00	−2.23
$F\,g$	20	+1.25	+.312	.390	+1.25	+ .39	+2.50	+ .78	−5.00	−1.56
$f\,G$	20	+1.25	+.312	.390	0	0	+8.75	+2.73	0	0
$G\,h$	25	−1.25	−.250	.312	0	0	−8.75	+2.18	0	0
$g\,H$	25	−1.25	−.250	.312	+7.50	−1.87	−2.50	+ .62	+5.00	−1.25
$H\,h$	22	+1.00	+.182	.182	−6.00	−1.09	+2.00	+ .36	−4.00	− .72
$A\,B$	20	+ .75	+.112	.084	0	0	0	0	0	0
$a\,b$	20	+ .75	+.112	.084	+ .75	+ .08	+1.50	+ 17	+2.25	+ .25
$B\,C$	36	− .75	−.062	.047	−1.50	+ .09	−3.00	+ .19	−4.50	+ .28
$b\,c$	36	− .75	−.062	.047	+ .75	− .05	+1.50	− .09	+2.25	− .14
$C\,D$	50	+ .75	+.045	.034	−1.50	− .07	−3.00	− .14	−4.50	− .20
$c\,d$	50	+ .75	+.045	.034	+2.25	+ .10	+4.50	+ .20	+6.75	+ .30
$D\,E$	50	− .75	−.045	.034	−3.00	+ .14	−6.00	+ .27	−9.00	+ .40
$d\,e$	50	− .75	−.045	.034	+2.25	− .10	+4.50	− .20	+6.75	− .30
$E\,F$	50	+ .75	+.045	.034	−3.00	− .14	−6.00	− .27	−9.00	− .40
$e\,f$	50	+ .75	+.045	.034	+3.75	+ .17	+7.50	+ .34	+6.00	+ .27
$F\,G$	36	− .75	−.062	.047	−4.50	+ .28	−9.00	+ .56	−3.00	+ .19
$f\,g$	36	− .75	−.062	.047	+3.75	− .23	+2.25	− .14	+6.00	− .37
$G\,H$	20	+ .75	+.112	.084	−4.50	− .50	+1.50	+ .17	−3.00	− .34
$g\,h$	20	+ .75	+.112	.084	0	0	+5.25	+ .59	0	0
Σ				7.436		− .33		+13.26		− .10

taken as 7 instead of unity, and the panel length and height are called 3 and 4 units, respectively. The complete calculations are given in the subjoined table. The values of the cross-sections are approximately what would be required for a railroad structure designed for an E-50 loading.

The stresses in $A\ a$ are then as follows:

$$\text{for load at } g,\ A\ a = -\frac{-.33}{7.436} = +\ .045$$

$$\text{for load at } f,\ A\ a = -\frac{13.26}{7.436} = -\ 1.784$$

$$\text{for load at } e,\ A\ a = -\frac{-.\ 10}{7.436} = +\ .013.$$

For loads of unity instead of 7 these stresses become, respectively, + 0.006, − 0.255, and + 0.002.

For loads at b, c, and d the stresses in $A\ a$ are the same as in $H\ h$ for loads at g, f, and e, respectively. Knowing the stresses in $A\ a$ for loads at g, f, and e, the corresponding stresses in $H\ h$ are readily found. They are − 5.96, + 0.216, and − 3.99 respectively; hence, dividing by 7, we have for stress in $A\ a$ for unit loads at b, c, and d, the values − 0.852, + 0.031, and − 0.570, respectively.

These values for stress in $A\ a$ are the shears in the end panel $a\ b$, of the full system as shown in Fig. 1. The shears in the dotted system are found by subtracting the above values from the total shear. The shears in the end panels of the two systems, for unit loads at each joint, are given below, together with the shears calculated on the assumption of independent action of the two web systems, and the percentage of error of the latter values.

The assumption of independent systems therefore gives somewhat too small results for the dotted system and too large results for the full system. The chief reason for this variation is the fact that, as regards shears in the left half of the truss, the dotted system is somewhat more rigid than the full system. In the right half the full system is the more rigid and the maximum in $g\ H$ will be the same as the maximum in $A\ b$, etc. Fig. 2 shows the values above given, plotted as influence lines for end shears or vertical components in the diagonals of the two systems. The dotted line $a'\ h$ represents the total shear.

For all joints loaded the true shear in panel de of the full system (vertical component in dE), is $1.638 - 2.00 = -0.362$, giving a tensile stress in dE. In the dotted system the shear (vertical component in De) is $1.363 - 1.00 = +0.363$, giving a tension in De

SHEARS IN THE END PANEL (FIG. 1) FOR UNIT JOINT LOADS

Joint Loaded.	Full System			Dotted System		
	True Shear.	Approx. Shear.	% Error.	True Shear.	Approx. Shear.	% Error.
g	$-.006$	0		$+.149$	$+.143$	-4.0
f	$+.255$	$+.286$	$+12.2$	$+.031$	0	
e	$-.002$	0		$+.431$	$+.429$	-0.5
d	$+.570$	$+.572$	$+0.4$	$+.002$	0	
c	$-.031$	0		$+.745$	$+.714$	-4.2
b	$+.852$	$+.857$	$+0.6$	$+.005$	0	
All Joints	$+1.638$	$+1.715$	$+4.7$	$+1.363$	$+1.286$	-5.7

equal to that in dE. The assumption of independent systems gives values of $\frac{2}{7}P$ or .286 for each, instead of .363.

The stresses in the centre diagonals being known, the stresses in DE and de are readily obtained by moments, and thence the stresses in the other chord members. The resulting value for $DE = (6 + .363)\frac{d}{h}P = 6.363\frac{d}{h}P$, compression, and in de a value of $(6 - .363)\frac{d}{h}P = 5.637\frac{d}{h}P$, tension. By the approximate methods, assuming independent systems and a shear in each system of $\frac{2}{7}P$, the values are $6.286\frac{d}{h}P$ and $5.714\frac{d}{h}P$, respectively. The errors involved are $.077\frac{d}{h}P$ in each case, or 1.2 per cent and 1.4 per cent. For other chord stresses the same absolute errors are involved, but the relative errors increase toward the end of the span.

From these calculations it may be concluded that the assumption of independent web systems, in the case of an odd number of panels,

will lead to results substantially correct, but that the assumption of zero stress in the central web members, under a symmetrical loading, is considerably in error. If approximate methods are to be used, the stresses for all conditions of loading should therefore be determined on the basis of separate action of the two web systems.

248. The Double Triangular Truss with Inclined End Posts.— Fig. 3 shows a more common arrangement of end posts than that of the truss analyzed in the preceding article. Such an arrangement, however, makes the determination of stresses by approximate methods

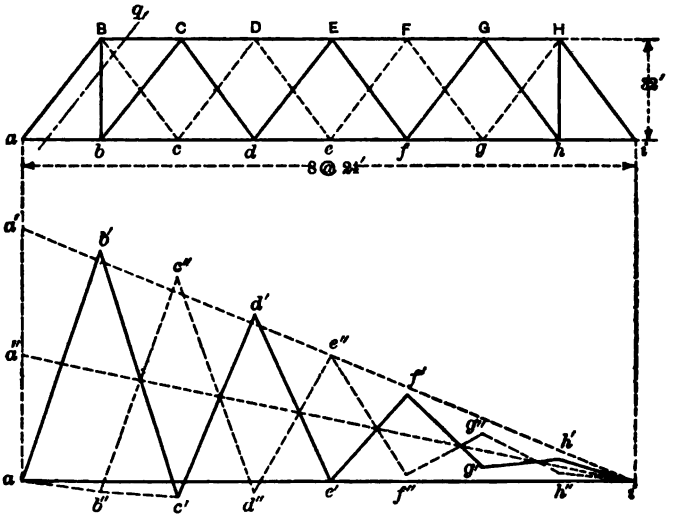

FIGS. 3 AND 4.

somewhat more uncertain than in the cases already considered. The joints B and H must be considered as belonging to both systems and loads at these joints must be divided in some approximate manner. An equal division is generally assumed. It is to be observed also that a load applied at b, or brought there by the member bC of the full system, is carried up to B where it then exerts an influence on the dotted system $B\,c\,D$. The complication arises from the fact that the two systems are connected at point B, which is itself not rigidly supported, a condition not present in the trusses previously considered. Inasmuch as this arrangement is common in the various forms of multiple intersection trusses, an analysis will be made of the truss of Fig. 3. The

same height and panel length will be taken as in Art. 247, and the same values of cross-sections. The values of A, u, and $u\,l/A$ for the various members are as follows, assuming $B\,b$ to be the redundant member:

Member.	A sq. in.	u	$\frac{u\,l}{A}$	Member.	A sq. in.	u	$\frac{u\,l}{A}$
$B\,b$	22	+1.00	+.182				
$B\,c$	20	−1.25	−.312	$B\,C$	36	+.75	+.062
$b\,C$	20	−1.25	−.312	$b\,c$	36	+.75	+.062
$C\,d$	14	+1.25	+.446	$C\,D$	50	−.75	−.045
$c\,D$	14	+1.25	+.446	$c\,d$	50	−.75	−.045
$D\,e$	12	−1.25	−.521	$D\,E$	58	+.75	+.039
$d\,E$	12	−1.25	−.521	$d\,e$	58	+.75	+.039
$E\,f$	12	+1.25	+.521	$E\,F$	58	−.75	−.039
$e\,F$	12	+1.25	+.521	$e\,f$	58	−.75	−.039
$F\,g$	14	−1.25	−.446	$F\,G$	50	+.75	+.045
$f\,G$	14	−1.25	−.446	$f\,g$	50	+.75	+.045
$G\,h$	20	+1.25	+.312	$G\,H$	36	−.75	−.062
$g\,H$	20	+1.25	+.312	$g\,h$	36	−.75	−.062
$H\,h$	22	−1.00	−.182				

The graphical method will be used in this case. Fig. 5 is a displacement diagram of the structure for the values of $\frac{u\,l}{A}$ given above. It is begun at h and $H\,h$ is assumed to remain vertical. The point b_1 on the diagram represents the cut end of $B\,b$, at a point near b. The vertical distance from b_1 to b in Fig. 5 represents the displacement of b_1 referred to b, and is the quantity $\Sigma\frac{u^2\,l}{A}$ of the formula. Call this deflection δ. Then, as in Art. 233, Part I, for a load unity on any joint as h, the quantity $\Sigma\frac{S'\,u\,l}{A}$ is equal to the deflection of h, due to forces of unity acting at b and b_1. Call this deflection δ_h. The stress in the member $B\,b$, due to unit load at h, is then equal to this deflection δ_h divided by the deflection δ. Before measuring the deflections of

the several joints it will be necessary to draw a correction diagram, the points a and i standing fast. This is shown in dotted lines.

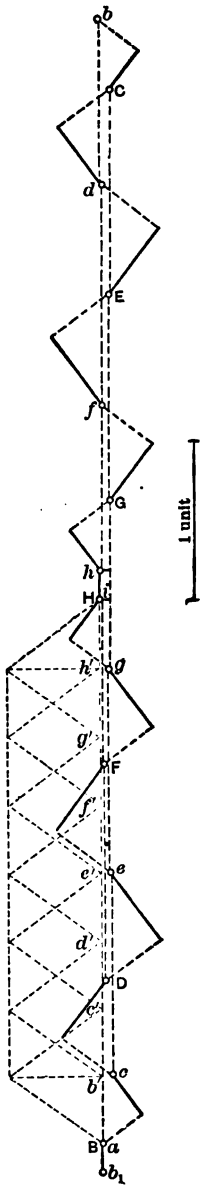

FIG. 5.

From the diagram the following deflections are measured:

$$\delta_h = -0.61 \qquad \delta_d = -4.72$$
$$\delta_g = -0.42 \qquad \delta_c = +0.42$$
$$\delta_f = -2.49 \qquad \delta_b = -6.61$$
$$\delta_e = 0.0$$

The deflection of b_1 with respect to $b = \delta = 7.20$. Dividing the above values by 7.20 we derive the stresses in $B\,b$ for unit loads at the several joints. These stresses will be the shears on section q carried by the full system. The shears carried by the dotted system (member $B\,c$) will be found by subtracting from the total shears the several stresses in $B\,b$. The resulting values in the two systems are as follows:

Joint Loaded.	Shear on Sec. q.	Stress in $B\,b$.	Vert. Comp. $B\,c$.
h	.125	+.084	+.041
g	.250	+.058	+.192
f	.375	+.345	+.030
e	.500	∞	+.500
d	.625	+.655	−.030
c	.750	−.058	+.808
b	.875	+.916	−.041
All loaded	3.500	+2.000	+1.500

In Fig. 4 these results are plotted as influence lines for $B\,b$ (shown by the full zigzag line), and for vertical component in $B\,c$ (shown by the dotted line). The line $a'\,i$ is the line for total shear, and if the systems of bracing were entirely independent the vertices of the influence lines would fall on this line and on the zero line $a\,i$. The variation from this assumption is clearly shown in the figure and also in the table given above. It

is noted that the load at h divides itself between the two systems, but that the larger part is carried by the full system (68 per cent); the load at g goes mainly to the dotted system, but a considerable part (about one-fourth) to the other system. At f the proportion taken by the dotted system is still smaller, while at e the load goes wholly to the system to which this joint belongs. For a full load, the member $B\,b$ carries exactly the load belonging to the full system, and hence for this condition the two systems may be taken as independent and the maximum chord stresses so found will be correct. The stresses in $d\,E$ and $E\,f = 0$.

For maximum stress in $b\,C$ and $C\,d$, load to d. Maximum shear in full system = .084 + .058 + .345 + .655 = 1.142 = vertical component in $b\,C$ and $C\,d$. By the approximate method, assuming the load at h to be equally distributed, shear $= \frac{1}{16} + \frac{3}{8} + \frac{5}{8} = 1.06$, an error of 8 per cent. For maximum stress in $d\,E$ and $E\,f$, load to f. Shear = .084 + .058 + .345 = .487. By the approximate method, shear = $\frac{1}{16} + \frac{3}{8} = .437$, an error of 11 per cent. For maximum in $B\,c$ load to c. Shear carried by $B\,c$ = 1.500 + .041 = 1.541. Approximate method gives 1.562, an error of 1.4 per cent. For maximum in $c\,D$ and $D\,e$, load to e. Shear = .763. Approximate method gives .812, an error of 6.4 per cent. For maximum in $e\,F$ and $F\,g$ load to g. Shear = .233 and approximate method gives .312, an error of 34 per cent.

From these calculations it may be concluded that in a truss of this type, with an even number of panels, the chord stresses are correctly found by assuming independent systems, and the web stresses will be found with a reasonable degree of accuracy on the same basis, it being assumed also that loads at b and h or B and H are equally divided between the two systems.

249. The Whipple Truss.—In the Whipple truss, Fig. 6, the approximate method of solution also leads to results very nearly correct. In the type shown in Fig. (*b*) the arrangement is somewhat more favorable than in Fig. (*a*), as in the latter case the loads at c or C are distributed over both systems in a manner not readily estimated. The two systems are not of equal flexibility, the full system containing six

members up to D, and the dotted system eight; the former will therefore carry more than one-half of the shear going to the right support. The entire shear is, however, small, and it may be assumed without material error, as in the triangular truss, that one-half is carried by each system.

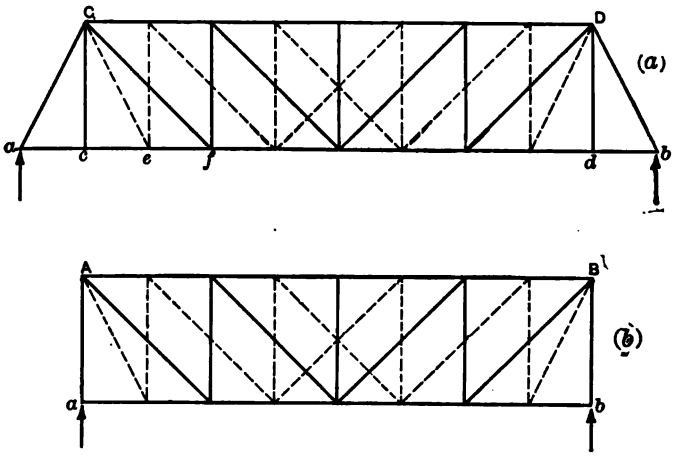

FIG. 6.

Loads at other joints will affect to a small extent the systems not belonging to the joint in question, but except for point c, independent systems may be assumed. The chord stresses will be correctly obtained for full load on the basis of independent systems. Winkler finds in a truss of 10 panels of type (b) an error of only 2 per cent in the maximum stress in web members.

250. Other Multiple Systems.—Fig. 7 illustrates a case of a double

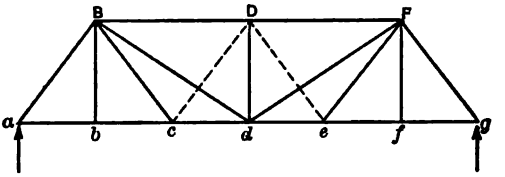

FIG. 7.

system of web members in which the two systems are very unlike in flexibility and the structure is not homogeneous. The dotted members may be considered as redundant. The loads at c and e can be carried by members $B\,c$ and $e\,F$ alone, and this path is much more rigid than

the path over the dotted members and thence down $D\,d$ and up the inclined members $d\,F$ and $b\,B$. As a result, the dotted members will be found to take much less than half the loads at c and e, and the stresses can only be guessed at unless the theory of redundant members be applied. Such irregular systems are undesirable and uneconomical as they cannot be designed so that the unit stresses are of the proper values in all the members.

Again, if the double system is to be used in a cantilever arm, as in Fig. 8, an odd number of panels as shown in Fig. (*a*) is better than an

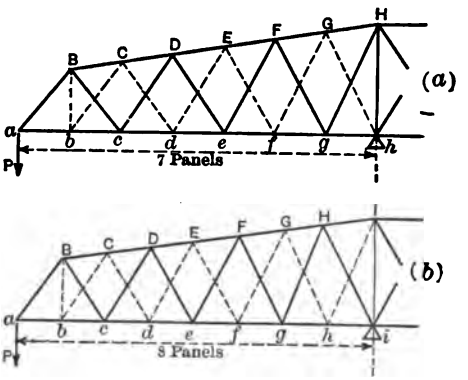

FIG. 8.

even number as in Fig. (*b*). The heavy concentration P is carried by the member $a\,B$ to the point B where it is divided between the two systems. In Fig. (*a*) the two paths over which it travels to the support on the right are $B\,b\,C\,d\,E\,f$, etc., and $B\,c\,D\,e\,F$, etc. These two paths contain an equal number of members and, for equal working stresses, have about the same rigidity. In Fig. (*b*) the number of panels from b to i is odd, and the dotted path from B to i contains nine members and the full path only seven. The two paths will therefore be quite unequal in rigidity and the full system will carry considerably more load than the other, assuming the same size of members. Being forced to deflect equally at B it follows that whatever the size of the members of the two systems, the unit stress in the dotted system will be considerably less than in the full system. Furthermore, this condition cannot be avoided no matter what the size of the several members.

Other illustrations of a similar sort might be given, as, for example, the combination of an arch and a truss. The arch, being the more rigid under symmetrical loads, will carry nearly all the load in such cases and the truss will serve mainly as a stiffening truss under moving loads, as in the case of the suspension bridge.

251. General Conclusions Regarding Multiple Systems.—From the results of the preceding analysis, and also from a general view of the matter, it may be concluded that, where multiple systems are so arranged as to be very nearly alike in design so that their relative rigidities will be about the same, the loads will distribute themselves nearly equally among the several systems, a condition which permits them to be assumed to act independently in the analysis. The slight uncertainty of stress in such systems is of small moment as compared to the advantages which they may afford in the case of very large structures especially with reference to convenient panel length and size of joint details. In fact their use will, in some respects, give a more homogeneous design and one freer from secondary stresses than a system of sub-paneling such as employed in the Pettit truss. For large structures where the web members of a double system are large enough to be of satisfactory size such a system is well worth consideration.

In one respect a structure with redundant members is theoretically not, in general, the most economical form. As illustrated by the foregoing discussion a structure with redundant members cannot be so designed that all members shall be subjected to any prescribed working stress. If there is, for example, one redundant member, the distortion of this member is fixed by the distortion of all the others; that is to say, its unit stress is a definite function of the unit stresses in all the other members, no matter what its size. In the example of the swing bridge of Art. 72 it was shown that, whatever the size of the centre diagonals, their unit stresses would be very small. This defect in structures with redundant members is of importance only in cases where the several parts or systems are of unequal flexibility, as in the example cited and in such a truss as shown in Fig. 7. This condition shows, however, that the principle of equal flexibility or rigidity of each part of a redundant system is essential not only for convenient calculation but for economy of design.

Again, in the double system with an odd number of panels, it is

seen that under full load, tension exists in both of the diagonals in the central panel, some shear being transmitted each way across this panel. This is, in general, an uneconomical arrangement and shows that an odd number of panels is not desirable. In a multiple intersection truss the principle of symmetrical arrangement and equal flexibility should therefore prevail.

252. The Double Triangular Truss with Verticals.—Not infrequently a case will arise where an analysis is required of a truss of the type shown in Fig. 9. This truss may be looked upon as a double triangular

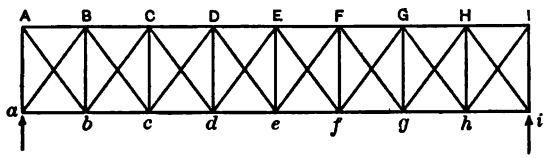

FIG. 9.

truss with the two systems connected at each panel point. Under this assumption the two diagonals of any panel are made of about equal size and the verticals are all alike (excepting the end posts), and of sufficient size to equalize the loads on the two systems, or to carry a half-joint load in tension, in case of a through bridge, or in compression, in case of a deck bridge.

In some respects a truss of this kind is advantageous as compared to the double system without verticals. It provides convenient points of attachment for the floor beams in the case of a through bridge, it avoids excessive variations in web stress due to concentrated loads passing from one system to another, and it reduces the secondary stresses, as will be shown in Chapter VII.

Under a full uniform load the verticals perform little service, as the deformations of the two diagonal systems are nearly alike and hence the verticals can receive but little stress. In this respect they are in a somewhat similar condition to the vertical stiffeners of a plate girder. Under partial loads, however, they tend rapidly to equalize the stresses in the two diagonal systems. To just what extent this is accomplished and the errors involved in an approximate analysis based on such an assumption, together with the probably maximum stress in any one vertical, may be approximately determined by the analysis of a typical

problem. Such an analysis will also serve to illustrate a case of several redundant members.

Assume dimensions as given in Fig. 10. The cross-sections of the members are also given in the figure. The two diagonals in each panel

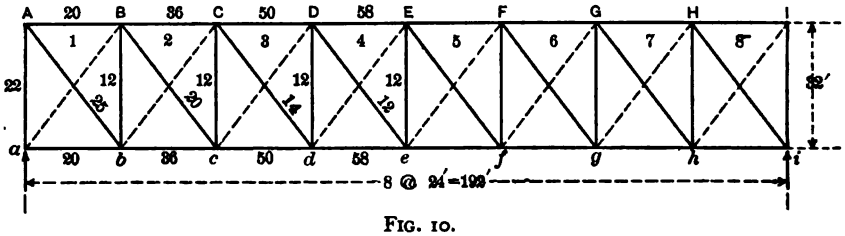

FIG. 10.

are assumed to be of equal section, and all verticals except the end posts are 12 sq. in. in area. The panels are numbered as shown.

There are eight redundant members in this structure, each intermediate vertical being redundant, and, in addition, one such member due to the double system. It will be more convenient in the analysis, however, to assume one of the diagonals in each panel as redundant, which, if removed, gives a Pratt system of bracing with no redundant members. The dotted diagonals will be assumed as the redundant members and their stresses will be called S_1, S_2, S_3, etc., the subscript corresponding to the panel in question.

253. *General Equations.*—With the truss loaded in any manner a series of eight equations may be written out, similar to eq. (3), Art. 243, in which the stresses in the eight redundant members appear as the unknowns. These are then determined by a solution of the eight equations. The modulus E will be omitted as it is constant. In these equations u_1, u_2, u_3, etc., are the stresses in the members due to tensile stresses of one pound in the several redundant members, No. 1, No. 2, etc., all other redundant members being removed excepting the one in question; and S' is the stress in any member due to the given loads, all the redundant members being removed in this case. It will be noted that the first equation contains the several products $\Sigma \frac{u_1^2 l}{A}$, $\Sigma \frac{u_1 u_2 l}{A}$, $\Sigma \frac{u_1 u_3 l}{A}$, $\Sigma \frac{u_1 u_4 l}{A}$, etc., and the second equation the

products $\Sigma \frac{u_2 u_1 l}{A}$, $\Sigma \frac{u_2^2 l}{A}$, $\Sigma \frac{u_2 u_3 l}{A}$, $\Sigma \frac{u_2 u_4 l}{A}$, etc. These products are independent of the loading on the structure and will be first determined.

254. *Values of* $\Sigma \frac{u^2 l}{A}$, *etc.*—Let Fig. 11 represent any panel, member No. 6 being the redundant member. Obviously a tension in this member will cause no stress in any member of the truss except in the quadrilateral *M m n N*. Represent the dimensions as shown, and number the members 1, 2, 3, 4, and 5. Then the stresses u and the products $\frac{u^2 l}{A}$ will be as given below (the term $\frac{l}{A}$ is included by considering that for the redundant member $u = +1$). The sectional areas of the chords are denoted by A_c and A'_c, of the verticals by A_v and A'_v, and of the diagonals by A_d and A'_d.

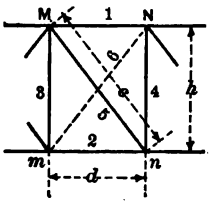

FIG. 11.

Member.	l	A	u	$\frac{u l}{A}$	$\frac{u^2 l}{A}$
1	d	A_c	$-\frac{d}{c}$	$-\frac{d^2}{c A_c}$	$+\frac{d^2}{c^2 A_c}$
2	d	A'_c	$-\frac{d}{c}$	$-\frac{d^2}{c A'_c}$	$+\frac{d^2}{c^2 A'_c}$
3	h	A_v	$-\frac{h}{c}$	$-\frac{h^2}{c A_v}$	$+\frac{h^2}{c^2 A_v}$
4	h	A'_v	$-\frac{h}{c}$	$-\frac{h^2}{c A'_v}$	$+\frac{h^2}{c^2 A'_v}$
5	c	A_d	$+1.0$	$+\frac{c}{A_d}$	$+\frac{c}{A_d}$
6	c	A'_d	$+1.0$	$+\frac{c}{A'_d}$	$+\frac{c}{A'_d}$

In this case the areas of the two chord members of any panel are equal, and also the areas of the two diagonals. The areas of the two

verticals are different for panels 1 and 8. We have then, in general, for any panel

$$\Sigma \frac{u^2 l}{A} = \frac{2 d^3}{c^2 A_c} + \frac{h^3}{c^2 A_v} + \frac{h^3}{c^2 A'_v} + \frac{2 c}{A_d}. \quad . \quad . \quad . \quad (9)$$

For simplicity the values of d, h, and c will be taken at 3, 4, and 5 units. Substituting these values in (9), and the values of A_c, A_v, and A_d for the several panels, we get values of $\Sigma \frac{u^2 l}{A}$ as follows:

Panel	$\Sigma \frac{u^2 l}{A}$
1	0.838
2	0.987
3	1.184
4	1.297
5	1.297
6	1.184
7	0.987
8	0.838

The values of $u_1 u_2$, $u_1 u_3$, etc., are very readily found in this case. The only members having a u_1 are those of the quadrilateral $A\ a\ b\ B$, and the only members having a u_2 are those of the quadrilateral $B\ b\ c\ C$, hence the member $B\ b$ is the only one having both a u_1 and a u_2. For this member the value of $u_1 = -\frac{h}{c}$ and the value of u_2 also equals $-\frac{h}{c}$, hence $\frac{u_1 u_2 l}{A} = +\frac{h^3}{c^2 A_v} = +0.213$. The only members having a u_3 are those of panel 3, and hence no member has both a u_1 and a u_3, therefore $\Sigma \frac{u_1 u_3 l}{A} = 0$. Likewise $\Sigma \frac{u_1 u_4 l}{A} = 0$, etc. It follows, in the same manner, that in the second equation of (3), $\Sigma \frac{u_2 u_1 l}{A}$ $= +0.213$, and $\Sigma \frac{u_2 u_3 l}{A} = +0.213$, and all other products of this kind are zero. Likewise in the third equation, $\Sigma \frac{u_3 u_2 l}{A} = +0.213$ and $\Sigma \frac{u_3 u_4 l}{A} = +0.213$, etc., etc.

255. *Values of* $\Sigma \frac{S' u l}{A}$.—The analysis will be made for a single load at each of the joints h, g, f, and e, so that the problem will be completely solved for any combination of loads. Inasmuch as the five members of a panel are the only ones that have a stress u due to

the stress in any one redundant member, the values of $\Sigma \frac{S' u l}{A}$ are readily calculated. Let $M\ m\ n\ N$, Fig. 12, represent any panel of the truss and suppose the truss to be loaded with a single load at any joint, either on the left or right. Let V = resultant of all forces on

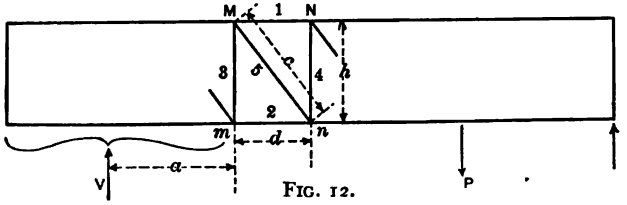

FIG. 12.

the left of a section through the panel, assumed as acting at a distance a from m, and taken as positive upward. Then the values of S' for the members of panel $m\ n$ are as follows: $m\ n = +\ V\ a/h$, $M\ N = -\ V\ (a + d)/h$; $M\ m = N\ n = -\ V$, $M\ n = V\ c/h$. If the load is applied at n then the stress in $N\ n = P - V$. The values of $\frac{S' u l}{A}$ for any panel are then as follows:

Member.	$\frac{S' u l}{A}$
1	$\frac{V\ (a + d)\ d^2}{h c\ A_c}$
2	$-\frac{V\ a\ d^2}{h\ c\ A'_c}$
3	$\frac{V\ h^2}{c\ A_v}$
4	$\frac{V\ h^2}{c\ A'_v}$
5	$\frac{V\ c^2}{h A_d}$

For $A_c = A'_c$ and $A_v = A'_v$ we have

$$\Sigma \frac{S' u l}{A} = V \left[\frac{d^3}{h c A_c} + \frac{2 h^2}{c A_v} + \frac{c^2}{h A_d} \right]. \quad . \quad . \quad . \quad . \quad . \quad (10)$$

Where the load is located at n, then the value of $\Sigma \frac{S' u l}{A}$ is increased by $-\frac{P h^2}{c A_v}$. In the end panels the term $\frac{2 h^2}{c A_v}$ is $\frac{h^2}{c A_v} + \frac{h^2}{c A'_v}$.

The remainder of the calculations are given in the following table.

VALUES OF $\frac{S' u l}{A}$ FOR JOINT LOADS OF 8 UNITS

Panel.	$\frac{d^2}{h c A_c}$	$\frac{2 h^2}{c A_v}$	$\frac{c^2}{h A_d}$	$\Sigma \frac{S' u l}{A}$ for $V=1$.	$\Sigma \frac{S' u l}{A}$ for $P=8$			
					Load at h.	Load at g.	Load at f.	Load at e.
(1)	(2)	(3)	(4)	(5)	(6)	(7)	(8)	(9)
1	.067	.413	.250	.730	+ .730	+1.460	+2.190	+2.920
2	.037	.533	.312	.882	+ .882	+1.764	+2.646	+3.528
3	.027	.533	.447	1.007	+1.007	+2.014	+3.021	+4.028
4	.023	.533	.521	1.077	+1.077	−2.154	+3.231	+2.176
5	.023	.533	.521	1.077	+1.077	+2.154	+1.099	−4.308
6	.027	.533	.447	1.007	+1.007	− .118	−5.035	−4.028
7	.037	.533	.312	.882	−1.250	−5.292	−4.410	−3.528
8	.067	.267	.250	.584	−4.088	−3.504	−2.920	−2.336

In Col. (5) are given the sums of the values in Cols. (2), (3), and (4). The load P is assumed to be eight units for sake of convenience in the calculation of shears. The several values of $\Sigma \frac{S' u l}{A}$ are found by multiplying the values in Col. (5) by the respective shears. Thus for load of 8 at h, the shear in all panels from 1 to 7 is unity and positive, hence for all panels from 1 to 6 the value of $\Sigma \frac{S' u l}{A}$ is the same as given in Col. (5). For panel No. 7 the load is at h and hence, as shown on page 353, the quantity $-\frac{P h^2}{c A_v}$, or -2.132, is to be added to this sum, giving a total of -1.250. In panel No. 8 the value of $\frac{2 h^2}{c A_v}$ is given as .267 only, as the member $I\,i$ has zero stress for S' in all cases. For load at h, the shear in panel $8 = -7$, hence $\Sigma \frac{S' u l}{A} = -7 \times .584 = -4.088$. For a load at g, the shear on the left of $g = 2$, and on the right it is -6, hence the values of $\Sigma \frac{S' u l}{A}$ are found by multiplying the values in Col. (5) by these shears respectively, and for the panel No. 6 adding the quantity -2.132 as before. The values for loads at f and e are found in a similar manner. We are now prepared to write out the several equations for a load at any joint.

256. *Solution of Equations.*—Following the general eq. (3) the several equations between the eight redundant stresses for a load at h are as follows:

$$
\begin{array}{lll}
(1) & .838\,S_1 + .213\,S_2 & = -.730 \\
(2) & .213\,S_1 + .987\,S_2 + .213\,S_3 & = -.882 \\
(3) & .213\,S_2 + 1.184\,S_3 + .213\,S_4 & = -1.007 \\
(4) & .213\,S_3 + 1.297\,S_4 + .213\,S_5 & = -1.077 \\
(5) & .213\,S_4 + 1.297\,S_5 + .213\,S_6 & = -1.077 \\
(6) & .213\,S_5 + 1.184\,S_6 + .213\,S_7 & = -1.007 \\
(7) & .213\,S_6 + .987\,S_7 + .213\,S_8 & = +1.250 \\
(8) & .213\,S_7 + .838\,S_8 & = +4.088
\end{array}
$$

The solution of these eight equations is a comparatively simple matter on account of the manner in which the unknowns appear. The work is given below in detail, and the explanation follows:

$$
\begin{array}{ll}
(1') & S_1 + .254\,S_2 = -.872 \\
(2') & S_1 + 4.63\,S_2 + S_3 = -4.14 \\
\hline
(a) & 4.38\,S_2 + S_3 = -3.27 \\
\hline
(a') & S_2 + .228\,S_3 = -.747 \\
(3') & S_2 + 5.56\,S_3 + S_4 = -4.73 \\
\hline
(b) & 5.33\,S_3 + S_4 = -3.98 \\
\hline
(b') & S_3 + .188\,S_4 = -.748 \\
(4') & S_3 + 6.09\,S_4 + S_5 = -5.06 \\
\hline
(c) & 5.90\,S_4 + S_5 = -4.31 \\
\hline
(c') & S_4 + .170\,S_5 = -.730 \\
(5') & S_4 + 6.09\,S_5 + S_6 = -5.06 \\
\hline
(d) & 5.92\,S_5 + S_6 = -4.33 \\
\hline
(d') & S_5 + .169\,S_6 = -.732 \\
(6') & S_5 + 5.56\,S_6 + S_7 = -4.73 \\
\hline
(e) & 5.39\,S_6 + S_7 = -4.00 \\
\hline
(e') & S_6 + .186\,S_7 = -.742 \\
(7) & S_4 + 4.63\,S_7 + S_8 = +5.87 \\
\hline
(f) & 4.44\,S_7 + S_8 = +6.61 \\
\hline
(f') & S_7 + .223\,S_8 = +1.490 \\
(8') & S_7 + 3.93\,S_8 = +19.19 \\
\hline
(g) & 3.71\,S_8 = +17.70 \\
(g') & S_8 = +4.770
\end{array}
$$

Dividing (1) and (2) by the coefficients of S_1 gives (1′) and (2′), and subtracting we get (*a*); then from (*a*) and (3) in like manner we get (*a*′), (3′), and (*b*); then from (*b*) and (4) we get (*c*), etc. Finally, from (*g*) we get $S_8 = +4.77$. Substituting back in (*f*′) we get S_7; then in (*e*′) we get S_6, etc. The values of the stresses in the several redundant members are given in the table below.

In like manner the stresses for loads of 8 units at the other joints are found. The results are all given in the following table:

VALUES OF STRESSES IN REDUNDANT MEMBERS

Panel.	Stresses S_1, S_2, etc., for a Load of 8 Units at Each Joint.			
	Load at *h*.	Load at *g*.	Load at *f*.	Load at *e*.
1	− .71	−1.44	−2.15	−2.88
2	− .61	−1.21	−1.82	−2.38
3	− .63	−1.25	−1.84	−2.65
4	− .63	−1.23	−2.00	−1.76
5	− .59	−1.37	−1.16	+3.26
6	− .82	− .53	+3.94	+2.35
7	+ .43	+4.86	+3.03	+2.62
8	+4.77	+2.93	+2.73	+2.12

For loads on the other joints the stresses can readily be obtained from the above values by considering the total shear in the panel. Thus for load at *d*, symmetrical with *f*, the stress in the member *a B* is the same as that in *Hi* for load at *f*. But for load at *f* the stress in *h I* = + 2.73, and as the shear = − 5.0, the stress in $H\,i = 5.00 \times \frac{5}{4} - .273 = 3.52$ compression, which is the desired stress in *a B*.

257. *Stresses and Influence Lines for the Diagonals.*—For convenience in determining maximum values the stresses in all the diagonals, both the redundant members and others, have been calculated for all panels in the left half of the truss, and for a load of eight units at each joint. The results are tabulated in table on next page.

The values of the stresses in the two diagonals of a panel indicate to what extent the verticals cause the shears to be equally divided between the two members. For loads somewhat remote from the panel in question the stresses are nearly equal, as, for example, for a load at

STRESSES IN ALL DIAGONALS FOR JOINT LOADS OF 8 UNITS

Joint Loaded.	Panel 1.		Panel 2.		Panel 3.		Panel 4.	
	aB	*Ab*	*bC*	*Bc*	*cD*	*Cd*	*dE*	*De*
h	− .71	+ .54	− .61	+ .64	− .63	+ .62	− .63	+ .62
g	−1.44	+1.06	−1.21	+1.29	−1.25	+1.25	−1.23	+1.27
f	−2.15	+1.60	−1.82	+1.93	−1.84	+1.91	−2.00	+1.75
e	−2.88	+2.12	−2.38	+2.62	−2.65	+2.35	−1.76	+3.24
d	−3.52	+2.73	−3.22	+3.03	−2.31	+3.94	+2.59	−1.16
c	−4.57	+2.93	−2.64	+4.86	+1.97	− .53	+1.13	−1.37
b	−3.98	+4.77	+1.68	+ .43	+ .43	− .82	+ .66	− .59
All joints	−19.25	+15.75	−10.20	+14.80	−6.28	+8.72	−1.24	+3.76

h or *g*, the stresses in the diagonals of panels 2, 3, and 4 are nearly equal. In panel 1 the member *a B* invariably receives the greater stress on account of it being the more direct path to the support at *a*. For a load at *f* the stresses in panel 4 are 2.00 and 1.75, showing a greater variation than for load at *g;* and for load at *e*, they are 1.76 and 3.24, or nearly as 1 to 2. In panel 3 they are 2.35 and 2.65 respectively.

These results are graphically shown in Fig. 13, plotted as influence lines for diagonal stress in the four panels. In each case the straight line *a' i* represents one-half of the shear. Fig. (*f*) shows the influence line for diagonal stress in panel No. 4 if no verticals are used. The equalizing effect of the verticals is very apparent. From these influence lines, the maximum stresses in the members *B c*, *C d*, and *D e*, are found to be about 10 per cent (11.4, 10.9, and 9.4 per cent) larger than if calculated on the basis of their carrying one-half of the shear. The maximum stresses in *b C*, *c D*, and *d E* are correspondingly smaller. In the end panel, the stress in *a B* is about 7.5 per cent greater and in *B a* 7.5 per cent less than one-half of the shear. Without the verticals, the stresses range from 15 per cent to 30 per cent greater than half the shear.

258. *Stresses in the Intermediate Verticals.*—The stress in any vertical is conveniently found from the stresses in the two diagonals meeting the vertical at the upper chord joint. A detailed analysis for loads of 8 units at the various joints gives the following results:

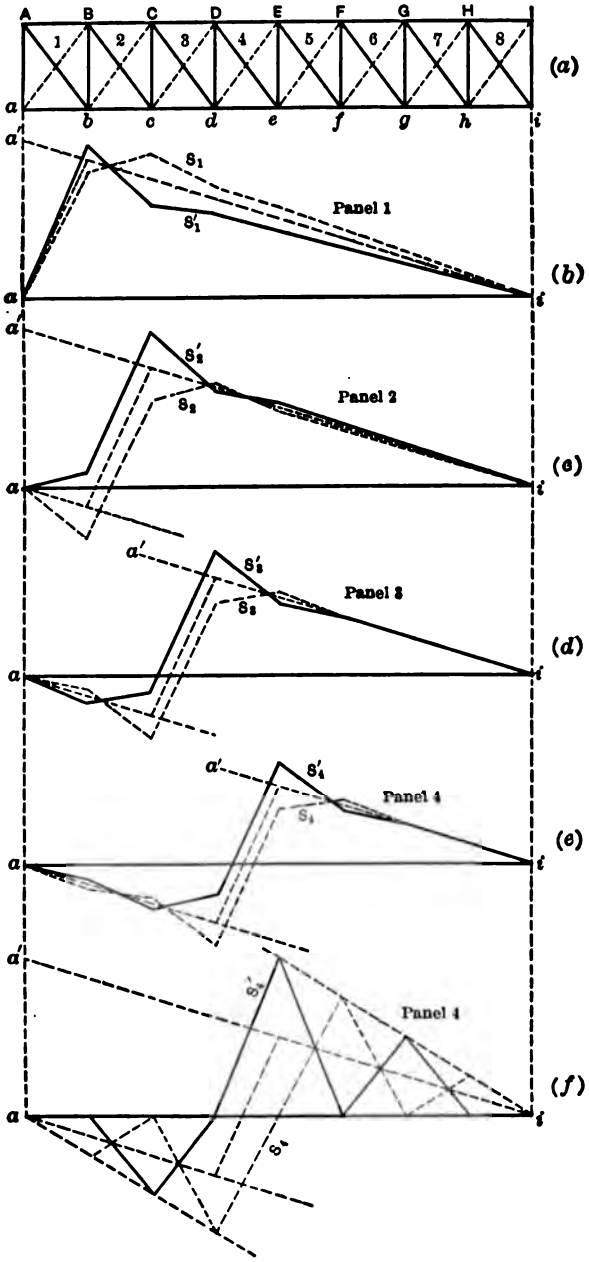
A
B
C
D
E
F
G
H
1
2
3
4
5
6
7
8
(a)
a
b
c
d
e
f
g
h
i
a'
S_1
S'_1
Panel 1
(b)
S'_2
S_2
Panel 2
(c)
S'_3
S_3
Panel 3
(d)
S'_4
S_4
Panel 4
(e)
S'_5
S_5
Panel 4
(f)

FIG. 13.

STRESSES IN THE VERTICALS FOR JOINT LOADS OF 8 UNITS

Joint Loaded.	*Bb*	*Cc*	*Dd*	*Ee*
h	+ .06	− .02	+ .01	− .02
g	+ .12	− .03	− .02	+ .08
f	+ .17	− .08	+ .07	− .47
e	+ .21	+ .02	− .47	+2.81
d	+ .39	− .58	+2.78	− .47
c	− .23	+2.53	− .48	+ .08
b	+2.84	− .69	+ .13	− .02
All joints	+3.56	+1.15	+2.02	+1.99

It is seen that the stresses due to loads at joints remote from the member in question are small. For a load at the adjacent joint the stresses are generally from 5 to 8 per cent of the joint load and compressive; and for a load at the joint, it ranges from 2.53 to 2.84 units, or from 32 per cent to 35 per cent of a joint load, and is tension. If the verticals were of larger section these stresses would be somewhat larger, approaching one-half of a joint load, and the diagonal stresses would be more nearly equalized; if smaller, their stresses would be less and the diagonal stresses more unequal. For loads at the upper joints, the stresses in the verticals would be compressive and about the same in amount as above given. For equal loads at upper and lower joints the stresses in the verticals would be practically zero.

259. *General Conclusions.*—For the double triangular truss with verticals it may be concluded from the above analysis that the stresses in the diagonals will be practically equalized except for loads at joints adjacent to the panel in question, and that the maximum stresses in the diagonals of any panel will not vary greatly from the half shear (about 10 per cent in the truss here analyzed). In the analysis of such a structure, therefore, closely approximate results will be reached on the basis of equal distribution of the shear. The errors in chord stress under this assumption will be very small near the centre and will increase toward the end, where they are the same as in the web members.

The maximum stresses in the verticals will be less than one-half of the excess of the joint load of the loaded chord above that of the un-

loaded chord. In a through bridge this stress will be tension and in a deck bridge, compression. The presence of verticals avoids excessive web stresses and local deformations, which occur in the ordinary double intersection truss, due to concentrated loads that may happen to be spaced about two panels apart. This condition is favorable to low secondary stresses as demonstrated more fully in Chapter VII.

260. General Case of Double Diagonals in a Pratt System.—In Art. 222, Part I, an example of equal double diagonals was analyzed, assuming the chord members to be indefinitely large and the verticals six times as large as the diagonals (as in an upper lateral system). In that case it was shown that the stresses in the two diagonals were nearly equal but of opposite sign. A more general solution will here be given so that the relative stresses for any such case can be determined by substitution. It is here assumed that both diagonals are in action. If both members are slender bars, this condition will require an initial tension equal to the calculated maximum compression.

Fig. 14 represents any such panel. V is the shear in the panel, or resultant of forces on the left, and is applied a distance a from m. Let the sectional areas be represented by A_c, A'_c, etc., as given in the table following. If member 6 be taken as the redundant member the values of u, ul/A, S', etc., are as follows:

Member.	l	A	u	$\frac{ul}{A}$	$\frac{u^2 l}{A}$	S'	$\frac{S'ul}{A}$
1	d	A_c	$-\frac{d}{c}$	$-\frac{d^2}{cA_c}$	$\frac{d^3}{c^2A_c}$	$-V\frac{a+d}{h}$	$+V\frac{(a+d)d^2}{hcA_c}$
2	d	A'_c	$-\frac{d}{c}$	$-\frac{d^2}{cA'_c}$	$\frac{d^3}{c^2A'_c}$	$+V\frac{a}{h}$	$-V\frac{ad^2}{hcA'_c}$
3	h	A_v	$-\frac{h}{c}$	$-\frac{h^2}{cA_v}$	$\frac{h^3}{c^2A_v}$	$-V$	$+\frac{Vh^2}{cA_v}$
4	h	A'_v	$-\frac{h}{c}$	$-\frac{h^2}{cA'_v}$	$\frac{h^3}{c^2A'_v}$	$-V$	$+\frac{Vh^2}{cA'_v}$
5	c	A_d	$+1$	$-\frac{c}{A_d}$	$\frac{c}{A_d}$	$+V\frac{c}{h}$	$+V\frac{c^2}{hA_d}$
6	c	A'_d	$+1$	$-\frac{c}{A'_d}$	$\frac{c}{A'_d}$	0	

The value of the stress in the redundant member is then written out from the general formula $S_r = -\dfrac{\Sigma \dfrac{S' u l}{A}}{\Sigma \dfrac{u^2 l}{A}}$. It is, therefore,

$$S_6 = -V \frac{d^2 c\left(\frac{a+d}{A_c} - \frac{a}{A'_c}\right) + h^2 c\left(\frac{1}{A_v} + \frac{1}{A'_v}\right) + \frac{c^4}{A_d}}{d^2 h\left(\frac{1}{A_c} + \frac{1}{A'_c}\right) + h^4\left(\frac{1}{A_v} + \frac{1}{A'_v}\right) + c^2 h\left(\frac{1}{A_d} + \frac{1}{A'_d}\right)}. \quad (11)$$

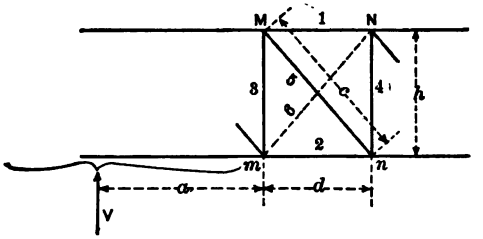

FIG. 14.

If the chords are nearly equal and the verticals also, as in the case of a lateral system, then

$$S_6 = -\frac{V}{2} \cdot \frac{\frac{d^3 c}{A_c} + 2\frac{h^3 c}{A_v} + \frac{c^4}{A_d}}{\frac{d^3 h}{A_c} + \frac{h^4}{A_v} + \frac{c^3 h}{2}\left(\frac{1}{A_d} + \frac{1}{A'_d}\right)}. \quad . \quad . \quad (12)$$

Again, if the chords and verticals are very large as compared to the diagonals, the terms containing these areas disappear and we have, approximately,

$$S_6 = -V \frac{c}{h} \cdot \frac{A'_d}{A_d + A'_d}, \quad . \quad . \quad . \quad . \quad . \quad (13)$$

that is, the stress in each diagonal will be proportional to its area, and the unit stresses in the two will be the same.

The above analysis excludes from consideration the effect of double diagonals in adjacent panels. The exact solution of such a case may be made in the same manner as the problem of the previous article.

261. The Counters of a Baltimore or Pettit Truss.—The true distribution of stress in the diagonals of a Baltimore or Pettit truss

may readily be determined in a manner similar to that used in the preceding article. Fig. 15 represents a panel in a Baltimore truss in which a counter $N\,O$ or $m\,O$ is required. It is assumed that there is sufficient initial tension in the members so that none will become slack. Assume $O\,N$ (No. 8) to be the redundant member, V = shear on section cutting panel $o\,n$, and P = load applied at O. The

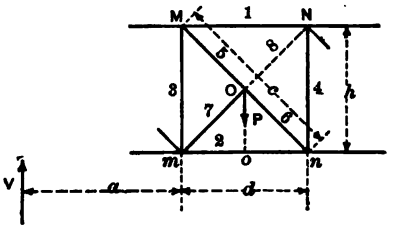

FIG. 15.

required calculations are given below. The areas of sections are designated as in Art. 260, the areas of the diagonals being called A_{d1} and A_{d2} for $M\,n$, and A'_{d1} and A'_{d2} for $m\,N$. The values of u are the same as in Art. 260.

Member.	l	A	u	$\frac{u\,l}{A}$	$\frac{u^2 l}{A}$	S'	$\frac{S'\,u\,l}{A}$
1	d	A_0	$-\frac{d}{c}$	$-\frac{d^2}{c\,A_0}$	$\frac{d^3}{c^2 A_0}$	$-V\frac{a+d}{h}$	$+V\frac{(a+d)\,d^2}{h\,c\,A_0}$
2	d	A'_0	$-\frac{d}{c}$	$-\frac{d^2}{c\,A'_0}$	$\frac{d^3}{c^2 A'_0}$	$+V\frac{a}{h}+\frac{P\,d}{2\,h}$	$-\frac{V\,a\,d^2}{h\,c\,A'_0}-\frac{P\,d^2}{2\,h\,c\,A'_0}$
3	h	A_v	$-\frac{h}{c}$	$-\frac{h^2}{c\,A_v}$	$\frac{h^3}{c^2 A_v}$	$-\left(V+\frac{P}{2}\right)$	$+\left(V+\frac{P}{2}\right)\frac{h^2}{c\,A_v}$
4	h	A'_v	$-\frac{h}{c}$	$-\frac{h^2}{c\,A'_v}$	$\frac{h^3}{c^2 A'_v}$	$-V$	$+V\frac{h^2}{c\,A'_v}$
5	$\frac{c}{2}$	A_{d1}	$+1$	$+\frac{c}{2\,A_{d1}}$	$\frac{c}{2\,A_{d1}}$	$+\left(V+\frac{P}{2}\right)\frac{c}{h}$	$+\left(V+\frac{P}{2}\right)\frac{c^2}{2\,h\,A_{d1}}$
6	$\frac{c}{2}$	A_{d2}	$+1$	$+\frac{c}{2\,A_{d2}}$	$\frac{c}{2\,A_{d2}}$	$+V\frac{c}{h}$	$+V\frac{c^2}{2\,h\,A_{d2}}$
7	$\frac{c}{2}$	A'_{d1}	$+1$	$+\frac{c}{2\,A'_{d1}}$	$\frac{c}{2\,A'_{d1}}$	$-\frac{P\,c}{2\,h}$	$-\frac{P\,c^2}{4\,h\,A'_{d1}}$
8	$\frac{c}{2}$	A'_{d2}	$+1$	$+\frac{c}{2\,A'_{d2}}$	$\frac{c}{2\,A'_{d2}}$	0	.

Then, as before, $S_s = \dfrac{\dfrac{S' u l}{A}}{\Sigma \dfrac{u^2 l}{A}}$, from which we derive

$$S_s = -\frac{V\left[d^2c\left(\frac{a+d}{A_o}-\frac{a}{A'_c}\right)+h^2c\left(\frac{1}{A_v}+\frac{1}{A'_v}\right)+\frac{c^4}{2}\left(\frac{1}{A_{d_1}}+\frac{1}{A_{d_2}}\right)\right]-\frac{P}{2}\left[\frac{d^2c}{A'c}-\frac{c^4}{2}\left(\frac{1}{A_{d_1}}-\frac{1}{A'_{d_1}}\right)-\frac{h^2c}{A_v}\right]}{d^2h\left(\frac{1}{A_o}+\frac{1}{A'_c}\right)+h^4\left(\frac{1}{A_v}+\frac{1}{A'_v}\right)+\frac{c^2h}{2}\left(\frac{1}{A_d}+\frac{1}{A_{d_2}}+\frac{1}{A'_{d_1}}+\frac{1}{A'_{d_2}}\right)} \quad . \quad (14)$$

If the chords and posts are large and A_{d1} is placed $= A_{d2} = A_d$ we have

$$S_s = -\frac{V\frac{c^4}{A_d}+\frac{Pc^4}{4}\left(\frac{1}{A_d}-\frac{1}{A'_{d_1}}\right)}{\frac{c^3h}{2}\left(\frac{2}{A_d}+\frac{1}{A'_{d_1}}+\frac{1}{A'_{d_2}}\right)} \quad . \quad . \quad . \quad (15)$$

and if $A'_{d1} = A'_{d2} = A'_d$, we have

$$S_s = -\frac{c}{h}\left[V\frac{A'_d}{A_d+A'_d}+\frac{P}{4}\cdot\frac{A'_d-A_d}{A_d+A'_d}\right]. \quad . \quad . \quad (16)$$

Comparing with eq. (13) it is seen that the stress carried by the counter $O\,N$ is the same as given by eq. (13), modified by the term $\frac{P}{4}\cdot\frac{A'_d-A_d}{A_d+A'_d}$, which is of little consequence. Hence we may say as in Art. 260, that the shear is distributed approximately as the sections of the diagonals, provided neither diagonal in question becomes slack through lack of initial tension or rigidity. In panel $m\,o$ the same principle will hold, and the stresses in $M\,O$ and $m\,O$ will be approximately as their sections, the one taking tension and the other compression.

In case some or all of the diagonal members are thin bars, incapable of carrying compression excepting by reason of initial stress, it is generally assumed that no compression will be carried by such members. In this case the member or members of the two panels which will first become slack are the ones that otherwise would receive the greatest compression. Suppose, for example, that all diagonals are eye-bars and that the shear in panel $o\,n$ is positive. The shear in panel $m\,o$ will then be a greater positive shear. Members 7 and 3

will tend to take compression and 7 more than 8. Hence 7 will slacken and the load at O will be carried by $O\ N$ acting as a sub-tie. If the shear in $o\ n$ is negative and that in $m\ o$ also negative, but smaller, $O\ n$ will tend to slacken more than $M\ O$ and hence may be considered as not acting. The member $M\ O$ will then act as a sub-tie. If the shear in $o\ n$ is negative and in $m\ o$ positive, then both $O\ n$ and $m\ O$ tend to slacken and the one may be omitted in the panel of the greater shear. Either $M\ O$ or $O\ N$ acts then as a sub-tie.

If $m\ O$ is made a compression member, then according to the same principles, when the shear in $o\ n$ is positive $m\ O$ will act and $O\ N$ become idle; and when the shear in $o\ n$ is negative, $O\ n$ will drop out whether the shear in $m\ o$ is positive or negative.

These conclusions accord with the assumptions made in the analysis of Part I. Similar assumptions may be made in the case of the Pettit truss.

Section II.—Lateral Truss Systems

262. Forms of Lateral Trusses and General Methods of Analysis.—Lateral truss systems, whether for trestles, towers, buildings, or bridge trusses, may be of the single Warren type, as in Fig. 16 (*a*), the double

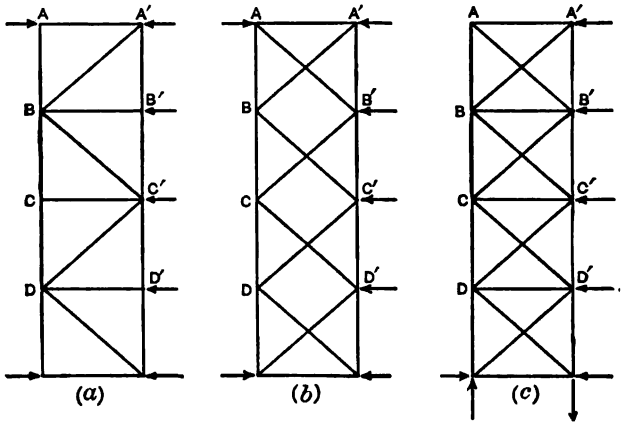

Fig. 16.

Warren type, Fig. (*b*), or the type shown in Fig. (*c*), which may be considered a double Warren type with verticals (in case the diagonals

are stiff members), or a Pratt type with two diagonals in each panel (in case they are slender rods or shapes incapable of taking compression). By reason of the fact that lateral struts are generally required for other purposes, the most common type of lateral system is the third.

In Figs. (*a*) and (*b*) the stresses due to the lateral forces are calculated without difficulty, the two systems in Fig. (*b*) being treated as independent. In Fig. (*c*) the stresses may be closely determined by a consideration of the principles illustrated in the problem of Art. 260. The chords being large and the lateral struts generally of good size, the shear may be assumed as equally divided between the two diagonals, if they are capable of carrying compression. In that case the stresses in the struts are small—not more than a half-panel load. If the diagonals are slender rods, then the Pratt system is to be assumed. If both diagonals are assumed to act equally, then the chord stresses are determined by moments taken at a transverse section through the point of intersection of the web members. The moments of the stresses in the two web members will cancel.

263. Stresses Due to Distortions of the Main Members.—In forms (*a*) and (*b*) the direct stress in the main members, either tension or compression, causes no stresses in the laterals, as these members can resist stress only to the extent that they are prevented moving laterally at B and B' or D and D', which is only through the bending resistance of the longitudinal members. In form (*c*), however, the presence of the members $B\,B'$, $C\,C'$, etc., prevents such lateral movement, and any direct stress in the main members will give rise also to some stress in the diagonals, with stresses of opposite sign in the lateral struts $B\,B'$, etc. In form (*a*) a compressive stress in the main members will cause them to be bent slightly to the left at B and B', to the right at C and C', and to the left again at D and D'. In form (*b*) they will be bent outward at B and B' and at D and D'. In form (*c*) they will be held more closely in line throughout. The secondary stresses due to this bending are greater in forms (*a*) and (*b*) than in form (*c*) and is a matter discussed more fully in Chapter VII. If the main members are in tension, as in the lower lateral system of a bridge, all conditions are reversed as to sign.

It will be desirable to estimate the stresses in form (*c*) due to stresses in the main members. Let Fig. 17 represent any panel in a lower

lateral system of a bridge truss, and let member $m\,N$ be taken as the redundant member. Consider equal longitudinal forces S_1 applied at M, N, m, and n, and let S_2 = the diagonal stress, assumed to be the

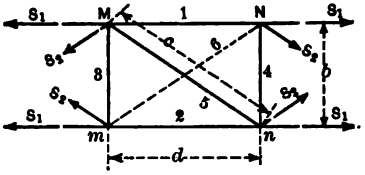

FIG. 17.

same in all members. The total longitudinal force acting at each joint is $S_1 + S_2\frac{d}{c}$, and is generally a known quantity. Call this force P. Then the calculations are as follows:

Member.	l	A	u	$\frac{ul}{A}$	$\frac{u^2 l}{A}$	S'	$\frac{S'ul}{A}$
1	d	A_c	$-\frac{d}{c}$	$-\frac{d^3}{cA_c}$	$\frac{2d^3}{c^2A_c}$	$+P$	$-\frac{2Pd^3}{cA_c}$
2	d	A_c	$-\frac{d}{c}$	$-\frac{d^3}{cA_c}$		$+P$	
3	b	A_v	$-\frac{b}{c}$	$-\frac{b^3}{cA_v}$	$\frac{2b^3}{c^2A_v}$	$-S_2\frac{b}{c}$	$\frac{2S_2b^3}{c^2A_v}$
4	b	A_v	$-\frac{b}{c}$	$-\frac{b^3}{cA_v}$		$-S_2\frac{b}{c}$	
5	c	A_d	$+1$	$+\frac{c}{A_d}$	$\frac{2c}{A_d}$	0	
6	c	A_d	$+1$	$+\frac{c}{A_d}$		0	

The value of S_6 is then equal to

$$S_6 = \frac{P\frac{d^3}{cA_c} - S_2\frac{b^3}{c^2A_v}}{\frac{d^3}{c^2A_c} + \frac{b^3}{c^2A_v} + \frac{c}{A_d}}. \quad \ldots\ldots \quad (1)$$

Noting that $S_6 = S_2$ we derive

$$S_6 = P \frac{\frac{d^2 c}{A_c}}{\frac{2 b^3}{A_v} + \frac{d^3}{A_c} + \frac{c^3}{A_d}}. \quad . \quad . \quad . \quad . \quad . \quad . \quad (2)$$

For the case where the vertical members are large, as the floor beams of a through bridge, we have, very closely

$$S_6 = P \frac{d^2 c A_d}{d^3 A_d + c^3 A_c}. \quad . \quad . \quad . \quad . \quad . \quad . \quad (3)$$

Suppose, for example, that $A_d = \frac{1}{4} A_c$ and $c = 1.3\, d$. Then $S_6 = 0.13\, P$. That is, the diagonal stress is 13 per cent of the total longitudinal force P. If the verticals in this case had an area equal to the diagonals, the value of S_6 would be $0.091\, P$.

It will be seen that the narrower the truss the greater the proportion of stress carried by the diagonals. In the end panels of a bridge the laterals are large and the chords small, so that a very considerable percentage may be carried by the former. The unit stress in the diagonals resulting from these indirect stresses can never be as great as that in the chords themselves, as they are stressed less for equal longitudinal distortion. From eq. (3) we have approximately (A_d being small as compared to A_c), $\frac{S_6}{A_d} = \frac{P}{A_c} \cdot \frac{d^2}{c^2}$. That is, the unit stress in the diagonal will be approximately equal to that in the chord multiplied by $\frac{d^2}{c^2}$ or by $\frac{d^2}{b^2 + d^2}$.

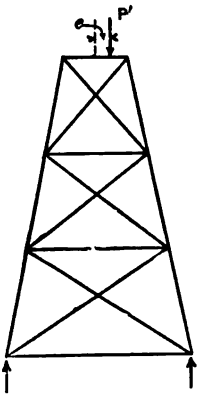

FIG. 18.

In the case of trestle towers of the form shown in Fig. 18, sufficiently approximate results may still be obtained by assuming all the stresses in the diagonals, due to vertical loads, to be equal. An unsymmetrical load P' is equivalent to a central load P' and a moment $P' \times \frac{e}{2}$. This moment, being uniform from top to bottom, causes little or no stress in the web members, while the central load P' is divided equally between the two posts and causes the same stresses in the web members

as above calculated. Hence we may say in general that the same stresses are caused in the lateral members whether the load is central or eccentric.

The braced arch with chords parallel, or nearly so (Fig. 19), is another form of truss in which the chord members generally are all

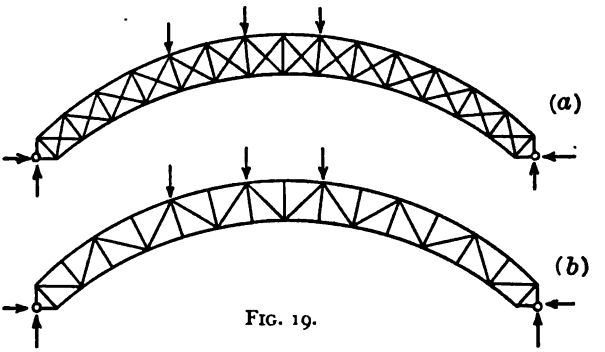

FIG. 19.

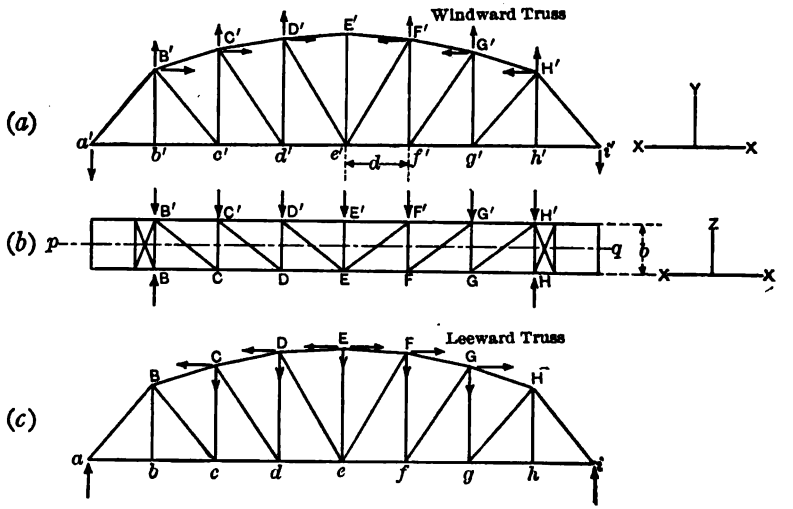

FIG. 20.

in compression. Such longitudinal deformation will cause considerable stress in a web system of the form shown in Fig. (*a*). And for the reasons already given, a system such as shown in (*b*), while comparatively free from lateral stress, is likely to be subjected to

large secondary stresses. (See Art. 345 for further consideration of this matter.)

264. Lateral Stresses in Curved-Chord Trusses.—Fig. 20 (*b*) represents the upper lateral system of a curved-chord truss. Under the lateral forces the shears in the panels of the lateral truss will be the same as if the truss were a plane figure. In analyzing such a structure these shears should first be found. Suppose then the stresses in the lateral diagonals be resolved into X, Y, and Z components, as indicated in the figure. Then the Z-component of any diagonal is equal to the lateral shear. The stress in any diagonal member = shear $\times \frac{\text{length}}{b}$. The stresses in the struts are equal to the shears. The same result will be reached if the upper lateral truss be flattened out or developed into a plane figure, and the stresses found as for a plane truss, using the actual joint loads.

The stresses in the diagonals having been found, the stresses in the members of the main truss are found as follows: Pass the vertical section, $p\,q$. At each joint of the main truss, as E, resolve the diagonal stress into three components. The Z-component is balanced by the joint load and the stress in the strut. The X and Y components act in the plane of the main truss as external loads. This resolution being carried out for each joint we have the main truss on the windward side acted upon by forces as shown in Fig. (*a*), and that on the leeward side as shown in Fig. (*c*). (The portal effect is confined to the lower chord.) These external forces produce certain stresses in the main members which are readily determined in the usual way.

265. Lateral Bracing Necessary for Rigidity of Trusses.—Let Fig. 21 represent an ordinary framed structure in space, consisting of two main trusses, $a\,A\,B\,b$, and $a'\,A'\,B'\,b'$, and two lateral trusses, $A\,A'\,B'\,B$ and $a\,a'\,b'\,b$. The structure is made rigid in cross-section by the diagonals $A\,a'$ and $B'\,b$ at the ends. Evidently no further bracing is necessary for rigidity. Such a structure may theoretically be supported at any three joints and still retain its form. A less amount of bracing will give a structure not rigid in itself and which needs support at more than three points.

The number of necessary members for rigidity of a structure in space can readily be determined as follows: Starting with the simplest

plane figure, the triangle, three members are required to fix three points, a, b, and c, Fig. 22. Having these points fixed, three additional members are required to fix a fourth point, d, not in the same plane. Then for another point, e, three more members will be required; and

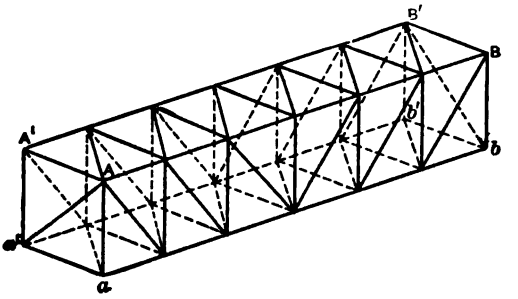

FIG. 21.

so on. Hence if m = total number of joints in the figure and n = number of necessary members, we have the relation

$$n - 3 = 3\,(m - 3), \quad \text{or} \quad n = 3\,m - 6. \quad . \quad . \quad . \quad (4)$$

This relation will sometimes assist in determining the question of redundancy in space. In Fig. 21, for example, there are 28 points, which will require $3 \times 28 - 6$, or 78 members for rigidity. A count of the members shows 25 in each main truss, 13 additional members in each lateral system, and two more in the end bracing, or 78 in all, which is just sufficient to satisfy the requirements. Transverse bracing in intermediate panels is redundant.

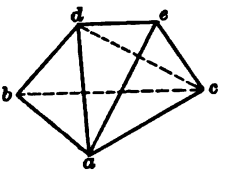

FIG. 22.

Rigidity may also be secured in Fig. 21, by omitting all but one of the lateral diagonals in one of the lateral systems and employing transverse bracing in each vertical panel. This gives the same total number of members as before. By the use of four supports a rigid system will result with transverse bracing in each panel and with all diagonals omitted in one lateral system. The use of two lateral trusses together with transverse bracing introduces redundancy, and while often desirable from a practical standpoint, this arrangement complicates the analysis somewhat, although in

most cases the stresses are not large and this difficulty is of little practical consequence.

266. Redundant Reactions.—Theoretically a rigid frame needs support at three joints only, and if we resolve all reactions into components in three directions, parallel to rectangular axes, the number of components need be only six to provide for loads acting in all directions. Supports at more than three joints, or supports so arranged as to involve more than six possible component forces, give rise to redundant reactions, the exact determination of which requires the application of the theory of redundant members, as for the swing bridge and the arch of less than three hinges. Stated in another

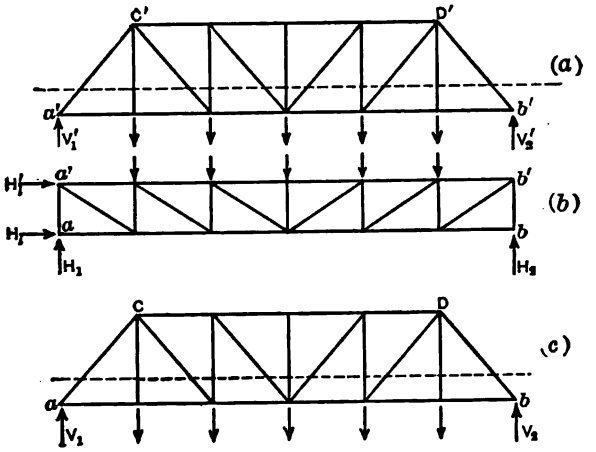

FIG. 23.

way, where reactions are redundant, they depend upon the dimensions of the members, and any errors in construction, or a settlement of supports, will cause stresses in the structure. Changes of temperature may also give rise to stresses in such structures. In the ordinary type of bridge structure redundant supports and redundant bracing are usually employed and the danger of undesirable stresses arising from such redundancy is generally of little consequence. However, as unusual conditions may require them to be considered, they will be briefly discussed.

Fig. 23, (*a*), (*b*), and (*c*), shows the usual provision for vertical and horizontal reactions for a bridge truss. Supports are provided at the

four points, a, a', b, and b'. The reaction components are eight in number; four vertical reactions for the two main trusses, two horizontal lateral reactions, H_1 and H_2, to resist wind and other lateral forces, and two horizontal reactions, H_l and H'_l, to resist longitudinal forces. The latter are supplied at the fixed end of the structure.

Theoretically, therefore, there are two redundant reactions. One of the vertical reactions may be considered as redundant and one of the horizontal reactions. Any three of the horizontal reactions would be sufficient for stability in a horizontal plane, but, obviously, such a combination as H_l, H'_l, and H_1 would be impracticable, as the structure would then act as a cantilever under wind forces, resulting in excessive lateral movements of the free end. The omission of one of the reactions H_l or H'_l would be admissible, as the longitudinal forces are small and reactions at a and b, as shown, would be sufficient. A fixed point at a, therefore, with the truss free to move in any direction at a' and b', and longitudinally at b, would provide fully for horizontal forces without redundancy.

Usually both a and a' are fixed, in which case a further redundant component is introduced at a', inasmuch as the reaction H_1 then becomes divided between the points a and a' in an indeterminate manner. Temperature changes will then also develop lateral reactions at a and a'. Practically, the ordinary truss is relatively so narrow that a rigid fastening at both a and a' are not objectionable. For wide structures, however, expansion and contraction need to be provided for by allowing free lateral movement of either a or a'. At the same time both points may be fixed as regards longitudinal movement.

The lateral forces being relatively small, and the lateral trusses flexible, the indeterminate character of the stresses due to redundancy of lateral supports in the ordinary bridge truss is of little importance and will not be further considered. The redundancy of vertical supports is of more importance, especially with reference to stresses caused by unequal settlement or other variation of level. This question will be considered more fully.

267. Stresses Due to Unequal Settlement of Supports.—In the construction of a large bridge, the ordinary procedure is such that the structure is fitted to its supports in the riveting of the lateral systems, so that slight irregularities in level of supports are taken care of.

Any subsequent settlement of one of the four supports, with respect to the plane of the other three, will cause stresses throughout the entire structure which will be now considered.

A deck structure will be considered with full end bracing, Fig. 24. The problem is solved by calculating the deflection of one point, as a, with respect to the plane of the other three, due to a force of unity

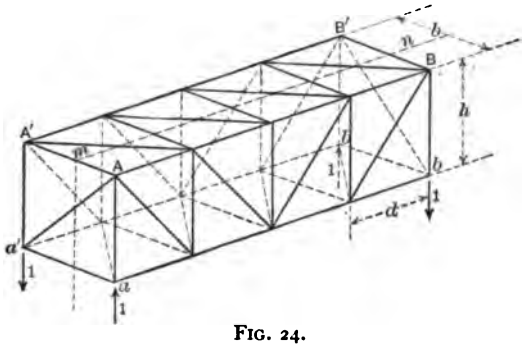

FIG. 24.

acting upward at a. The corresponding reactions at the other supports will also be unity as indicated. The stresses u in all the members, due to these forces, are determined and then the desired deflection of a is found from the usual equation $\Delta = \Sigma \frac{u^2 l}{EA}$.

In finding the stresses u it is convenient to first pass a plane $m\,n$, cutting all the lateral members. Since there is no external load acting at any joint excepting at the four points, a, a', b', and b, the lateral or Z-components of all the lateral members are equal to each other, as shown by considering the lateral forces acting at any joint. Let U be this lateral component. Then let the stresses in all the upper and lower diagonals be resolved into Z- and X-components, and the stresses in the end diagonals into Z- and Y-components. The X-components of the upper and lower lateral diagonals will be equal to $U \times \frac{d}{b}$, and the Y-components of the end diagonals will be $U \frac{h}{b}$.

Consider now the forces acting on one of the vertical trusses (Fig. 25). At each joint where a lateral diagonal is connected there will be a horizontal force equal to $U \frac{d}{b}$, and at the end joints A and b there

will be vertical forces of $U\frac{h}{b}$. The Z-components of the lateral diagonals and struts act at right angles to the plane of the main truss and balance each other. The various forces shown in Fig. 25 are therefore

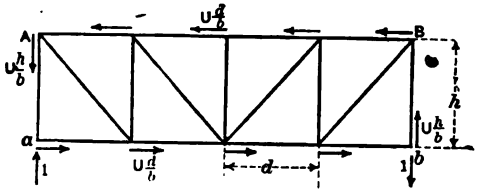

FIG. 25.

in equilibrium; hence we have, from moments about b, if n = number of panels,

$$1 \times n\,d = U\frac{d}{b} \cdot n\,h + U\frac{h}{b} \cdot n\,d,$$

whence

$$U = \frac{b}{2\,h}. \qquad \ldots\ldots\ldots \quad (5)$$

The value of U being found from (5), the remaining stresses are readily found, and thence the value of $\Sigma \frac{u^2 l}{EA}$.

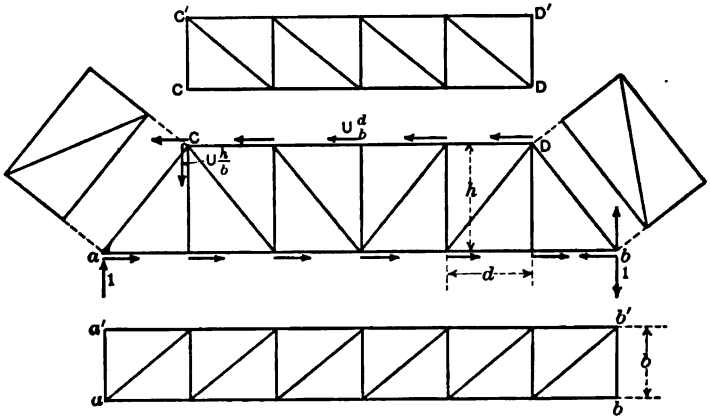

FIG. 26.

In the case of inclined end posts and full diagonal bracing, Fig. 26, the equation of moments gives

$$U = \frac{n}{n-1} \cdot \frac{b}{2h}. \quad \ldots \ldots \quad (6)$$

In the case of curved-chord trusses the lateral or Z-components will still be equal, but the diagonals of the laterals of the curved chord will have both vertical and horizontal components, as in Art. 264.

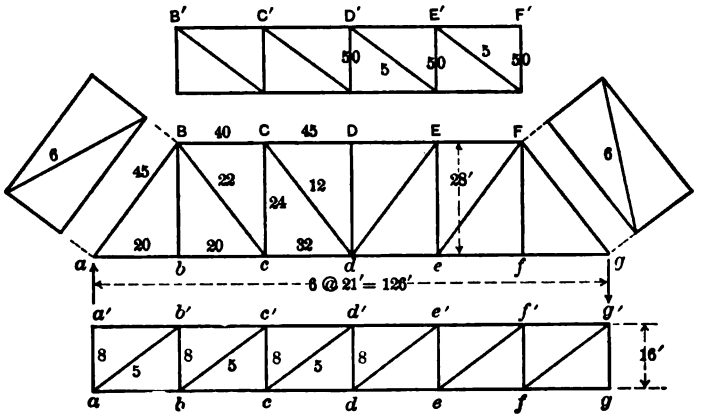

FIG. 27.

EXAMPLE.—Take a Pratt truss of six panels, with dimensions and cross-sections as given in Fig. 27. The lateral diagonals which are shown are those that will be in tension, with reactions at a and g as indicated.

The value of U is, from eq. (6), equal to $\frac{6}{5} \times \frac{16}{56} = 0.343$. Then $U\frac{d}{b} = 0.450$ and $U\frac{h}{b} = 0.600$. The horizontal force acting at each joint of the main truss is therefore 0.450, and the vertical forces at B and g are 0.600. These being known, the stresses in all the members are readily found. The value of $\Sigma \frac{u^2 l}{EA} = 0.0000156$, which is the deflection in inches for a one-pound reaction. A settlement of one-tenth inch therefore causes a change in reaction of 0.1/0.0000156 or 6,400 lbs. Such a reaction produces stresses in all members of $6{,}400 \times u$. For all laterals the lateral component of such stress will be $.343 \times 6{,}400$ or 2,200 lbs. This example indicates the relative importance of stresses due to settlement of supports.

In the case of a through bridge the end bracing consists of portals instead of full diagonal bracing. The stresses in all members of the structure, except the members of the portals, due to the one-pound

reaction will be the same as in the case already considered. In the portal there will be bending moments as well as direct stress. The quantity $\frac{u^2 l}{EA}$ will then be calculated for all direct stresses and $\int \frac{m^2 dx}{EI}$ for all members acting as beams. In the latter expression m is the bending moment at any section due to the one-pound reaction. The sum of all terms $\frac{u^2 l}{EA}$ and $\int \frac{m^2 dx}{EI}$ will give the desired deflection.

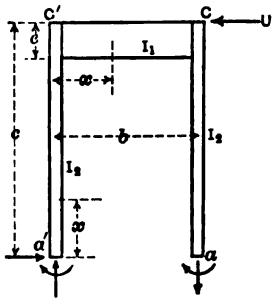

FIG. 28.

In the example given suppose the end bracing consists of a portal of the dimensions shown in Fig. 28; $c = 420$ in., $b = 192$ in., $I_1 = 4{,}000$, $I_2 = 2{,}000$. Assuming fixed ends, the value of m for the posts is approximately $\frac{U}{2}\left(\frac{c}{2} - x\right)$, and for the beam $C\,C'$ it is $\frac{U}{4}c - U\frac{c}{2b}x = \frac{Uc}{2} \times \left(\frac{1}{2} - \frac{x}{b}\right)$. Integrating the value of $\frac{m^2 dx}{EI}$ for the post from o to c, and for the beam from o to b, we have the following:

	m	m^2	$\int \frac{m^2 dx}{EI}$
Post.....	$\frac{U}{2}\left(\frac{c}{2} - x\right)$	$\frac{U^2}{4}\left(\frac{c^2}{4} - cx + x^2\right)$	$\frac{U^2 c^3}{48 E I_2}$
Beam.....	$\frac{Uc}{2}\left(\frac{1}{2} - \frac{x}{b}\right)$	$\frac{U^2 c^2}{4}\left(\frac{1}{4} - \frac{x}{b} + \frac{x^2}{b^2}\right)$	$\frac{U^2 c^2 b}{48 E I_1}$

The total value of $\Sigma \int \frac{m^2 dx}{EI}$ is therefore $U^2\left(\frac{c^3}{24 E I_2} + \frac{c^2 b}{48 E I_1}\right)$. Substituting numerical values, this is found to be equal to $U^2 \times \frac{1{,}720}{E} = \frac{202.4}{E}$. In the case of the full diagonal bracing, instead of this term we had the value of $\frac{u^2 l}{EA}$ for the diagonal member. This amounted to $\frac{52.4}{E}$. Thus the portal frame lends to the distortion or deflection about four times as much as the full diagonal bracing. The total deflection is in this case 0.000026 in. in place of 0.0000156 for the fully braced ends, or almost double. This

illustrates very well the flexibility of portals as compared to full diagonal bracing.

268. Stresses in Lateral Trusses Due to Vertical Loads.—The usual form of lateral bracing, arranged symmetrically with respect to the centre of the structure, receives no stress from vertical loads excepting that due to the distortions of the chords of the main trusses as explained in Art. 263. In the lateral system shown in Fig. 27, the members are not arranged symmetrically and it will be found that vertical loads on the main trusses will cause slight stresses in the laterals, for the summation $\Sigma \frac{S' u l}{E A}$ will not be zero.

In the solution of such a problem one of the laterals may be taken as the redundant member. The stresses S' are then simply the stresses

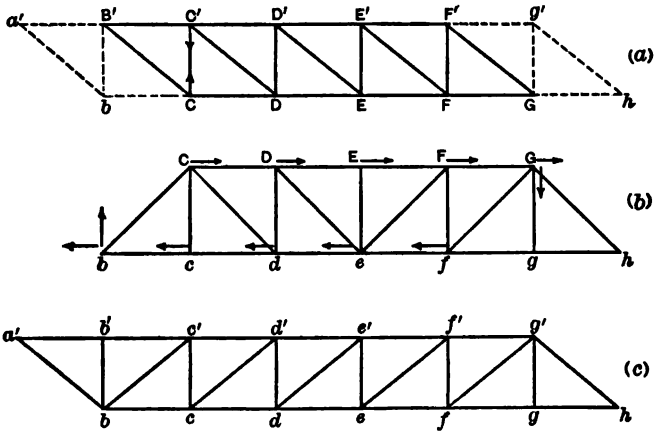

FIG. 29.

in the main trusses due to the vertical loads. The stresses u will be the stresses in all the members due to a one-pound tension in the lateral. These are readily found. The forces acting on the main truss will be similar to those shown in Fig. 26, but here the value of U is unity, and the end reactions are to be determined.

In the case of a skew bridge the lateral stresses due to vertical loads are considerable, especially in a double-track structure where the skew is large. As an example of such a case assume a truss of the general dimensions and sectional areas given in Fig. 27, but built in the form shown in Fig. 29, the skew being one panel. Suppose one of

the trusses ($b\,C\,G\,h$) be loaded with a unit load at each upper joint. Let it be required to determine the resulting stresses in the laterals.

Assume any one of the laterals, as $C\,C'$, to be the redundant member. The stresses u will be the stresses throughout the structure due to a one-pound tension in this member. They are found as explained in Art. 267. The lateral component of all lateral members will be unity, tension in some and compression in others. The stresses S' will be those in truss $b\,C\,G\,h$, due to the vertical loads only. Calculating the summations $\Sigma \frac{S'\,u\,l}{A}$ and $\Sigma \frac{u^2\,l}{A}$, we find the stress in $C\,C'$, from the formula $S_r = -\Sigma \frac{S'\,u\,l}{A} \Big/ \Sigma \frac{u^2\,l}{A}$, to be $-$ 0.129 lbs.

The relation of the skew to the lateral arrangement being the same, when viewed from either side, it is evident that unit joint loads on the truss $a'\,B'\,F'\,g'$ will cause a stress in $F\,F'$, and the lateral struts in general, of 0.129 lbs. compression. If the load per lineal foot is 5,000 lbs., the total floor-beam load is 5,000 × 21 = 105,000 lbs., and the stress in each lateral strut, due to such load, will be 105,000 × 0.129 = 13,500 lbs. compression, and in each diagonal it will be $13{,}500 \times \frac{317}{192}$ = 22,300 lbs. tension. The unit stresses for the areas assumed will be 270, 1,700, and 4,460 lbs. per sq. in. respectively.

The use of smaller laterals will result in a greater flexibility and a smaller stress in each member, but the unit stress will be slightly larger.

269. Transverse Bracing.—As shown in Art. 265, a bridge may be considered as fully braced when provided with an upper and a lower lateral system and end bracing. For sake of additional rigidity against lateral vibration under moving loads, transverse bracing is generally inserted at each panel point. In through bridges this is made of portal form and as deep as the head room will permit; in deck bridges it consists of full diagonal bracing. This intermediate transverse bracing may be considered as redundant, and an exact analysis of its stresses can be made only on that theory. However, it is not important that an exact analysis be made, as the stresses are small under any reasonable assumption, and minimum sections are generally sufficient.

The stresses in the transverse bracing will be considered in two parts: (*a*), the stresses due to lateral forces such as wind pressure, and

(*b*), the stresses due to vertical loads applied unequally upon the main trusses.

270. (*a*) *Stresses Due to Lateral Forces.*—Consider any panel, *D d*, of a through bridge, Fig. 30. Lateral forces applied at the panel

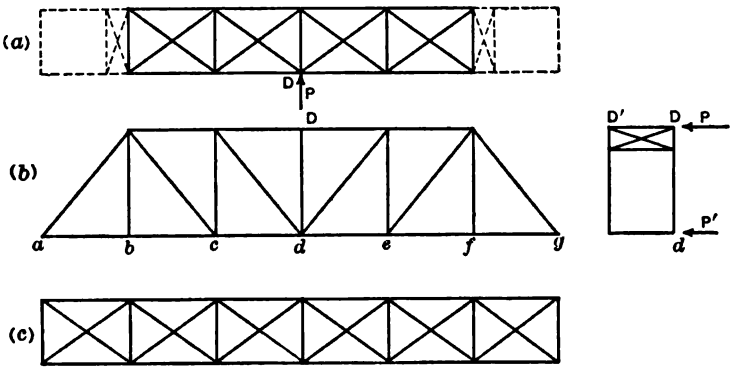

FIG. 30.

are P and P'. Were the transverse bracing not present, the load P would be carried wholly by the upper laterals to the portal and thence to the supports; and the load P' would be carried wholly by the lower laterals to these same points. The transverse bracing, however, connects the two lateral systems at each panel point and modifies more or less this distribution of the load.

The relative amount of stress in the transverse frame may be estimated by considering the deflections of the lateral systems at D and d. The joint load P is much smaller than P', and, likewise, the sections of the upper lateral members are smaller than those of the lower system. On the whole, the sections are in proportion to the loads, and hence the unit stresses and deflections in the two lateral systems will be approximately the same under full load. If the upper lateral system were of the same length and was supported at the ends in the same manner as the lower system, the deflections would be equal and therefore the transverse bracing would remain practically unstressed. Instead of this being the case, however, the upper laterals transmit their load down the portals, which are much more flexible than full diagonal bracing. Hence the upper laterals, with the portals, constitute a more flexible path than the lower laterals. The point D will,

therefore, tend to deflect more than d, and to throw some stress on the transverse bracing, with a corresponding additional load upon the lower laterals. Inasmuch, however, as the intermediate transverse bracing is more flexible than the end portals, the proportion of the load P which will be transferred to the lower laterals by means of the transverse bracing will be small. An assumption commonly made is that the transverse bracing may transmit as much as one-half the upper load, P. The upper laterals are, at the same time, designed to carry all the upper loads and the lower laterals the lower load. These assumptions are sufficient for all ordinary cases of simple truss spans.

If the bridge is a deck structure the end bracing will be full diagonal bracing, and each lateral system will be more nearly equal in flexibility. In this case the transverse bracing will be but slightly stressed.

In general, the distribution of loads in the case of redundant lateral systems can be estimated with sufficient accuracy by considering the relative rigidities of the several systems. If one complete system (preferably the most rigid one) is made sufficient to carry the entire load, the auxiliary systems may, with entire safety, be designed arbitrarily. Their object is usually to increase the general stiffness of the structure, and minimum sections consistent with this end are suitable for the purpose.

271. (*b*) *Stresses Due to Unequally Loaded Main Trusses.*—When the vertical trusses are unequally loaded, as in the case of a double-track bridge, their deflections will be unequal and the transverse frame will tend to throw the trusses out of a vertical position. If it were not for the lateral bracing there would be very little resistance to such warping of the main trusses, and the stresses in the transverse bracing would be very slight. Where, however, an upper and a lower lateral system exist, such warping is resisted, and to that extent throws stress upon the transverse frame. Under unsymmetrical loads, therefore, the transverse bracing receives some stress, the amount depending upon its rigidity and the rigidity of the lateral trusses. The maximum effect will occur in the case of a deck bridge where the transverse frames and end bracing are composed of diagonals under direct stress. Such a structure will be considered in detail.

Let Fig. 31 represent the transverse section of a deck bridge, and P an eccentric load. The load transferred to the truss $D\,d$ will be

$P\left(\frac{1}{2} + \frac{e}{b}\right)$, and to the truss $D'\,d'$ will be $P\left(\frac{1}{2} - \frac{e}{b}\right)$. The excess on $D\,d$ over $D'\,d'$ will be $\frac{2\,P\,e}{b}$, which is the only portion of the load which need be here considered. A similar condition will exist at all the other panel points.

An exact solution of this problem would require the simultaneous consideration of all the transverse frames, each one furnishing one redundant member. However, for the purposes of this discussion, it will be sufficient to consider a single panel, such as $D\,d$, with its transverse bracing, and determine the stresses in the diagonal of such bracing due to a load of one pound applied at D.

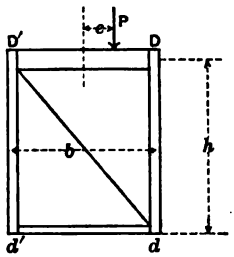

FIG. 31.

We will assume a truss of the dimensions shown in Fig. 27. Transverse diagonal bracing will be assumed in panel $D\,d$, consisting of two bars of 2 sq. in. each. If a considerable initial tension is applied these may be considered equivalent to a single member of 4 sq. in. in area, arranged as shown in Fig. 31. A load of 1 pound is applied at D and the problem is to determine the tensile stress in the transverse diagonal due to this one-pound load. It is solved in the usual way by the theory of redundant members. The diagonal $D'\,d$ is taken as redundant, and the stresses u determined throughout the entire structure due to a one-pound tension in this member (including the value $u = 1$ for this member itself); also the stresses S' in the truss $a\,B\,F\,g$, due to the vertical load of one pound at D. Then the stress in $D'\,d = \Sigma\,\frac{S'\,u\,l}{A} \Big/ \Sigma\,\frac{u^2\,l}{A}$. The result of this calculation is a tension in $D'\,d$ of 0.20 lb. The vertical component of this is 0.175 lb. That is, the transverse bracing transfers 17 per cent of the load at D to the opposite truss.

In this calculation it is found that the deformation of the member $D'd$, itself, has a large influence on its stress. If, for example, it is made 2 sq. in. in area instead of 4 sq. in., its resulting stress will be 0.166 lb., with a vertical component of 0.144 lb., a decrease of 17 per cent.

Again, if the bridge were a through bridge instead of a deck structure, with the portal form of end and transverse bracing, the flexibility of the lateral systems would be more than doubled, reducing the possible load transferred to less than half of the above values. In such a case it is a very liberal estimate to assume that 10 per cent of the excess vertical load may be transferred to the opposite truss.

In double-track bridges the excess load on the near truss is approximately one-half the total load on one track. Ten per cent of this will equal 250 to 300 lbs. per foot, as the amount transferred. The lateral component of this will be only about one-half, or 125 to 150 lbs. per foot as the load on the lateral trusses due to eccentric loads.

We may therefore conclude, in general, that the stresses in the transverse frame from eccentric loads will not be greater than that caused by assuming one-half the lateral load on the unloaded chord to be carried by the transverse frame.

272. Proportions of Lateral Bracing for Maximum Ridigity.— In many cases the question arises as to the most suitable panel

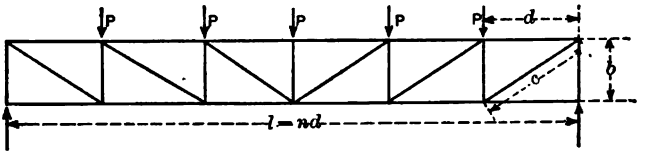

FIG. 32.

length for the lateral system. Thus, for example, where the panel length of the main truss is long, either one or two panels of the lateral system may be made to correspond with one panel of the main truss; or, on the other hand, in double track bridges of short panel, the panel length of the lateral truss may be made equal to either one or two panels of the main truss. In general, the panel length selected should be such as to give the maximum ridigity to the lateral system for the given working stresses. An approximate theoretical analysis of this problem will be of some assistance in selecting the best proportions.

Let Fig. 32 represent any lateral truss of n panels. Under a load P the truss will deflect a distance determined by the formula $\Sigma \frac{Sul}{EA}$. It will be assumed that the chord members are large as compared to

the web members so that their influence upon the deflection may be neglected.

Let f_t = working stress in the diagonal members and f_c = working stress in the struts. Under full load the stress S in any member will be approximately equal to $f_t A$, or $f_c A$, as the case may be. The stress u, for deflection at the centre, will be ½ for each strut and $\frac{c}{2b}$ for each diagonal. Hence, summing the products $\frac{S u l}{E A}$ we get, for the struts, $\Sigma \frac{S u l}{E A} = \frac{n b f_c}{2 E}$, and for the diagonals, $\Sigma \frac{S u l}{E A} = \frac{n c^2 f_t}{2 b E}$. The deflection is therefore

$$\Delta = \frac{n}{2 b E} (b^2 f_c + c^2 f_t). \quad . \quad . \quad . \quad . \quad . \quad (6)$$

For a variable panel length d, we have $n = l/d$. Substituting in (6), and placing $c^2 = b^2 + d^2$, we get, in terms of d, etc.,

$$\Delta = \frac{l}{2 E d b} [b^2 (f_c + f_t) + d^2 f_t]. \quad . \quad . \quad . \quad . \quad (7)$$

Differentiating this with respect to d, equating to zero, etc., we find that for a minimum value of Δ, or for maximum rigidity, the length of panel is

$$d = b \sqrt{\frac{f_c + f_t}{f_t}}. \quad . \quad . \quad . \quad . \quad . \quad . \quad (8)$$

If, for example, f_c is approximately equal to ½ f_t, we have $d = 1.22\ b$. Where the struts are very large, as in the case of floor beams used as struts, then f_c may be placed equal to zero and for maximum rigidity, $d = b$.

Section III.—The Quadrangular or Portal Frame

273. The Quadrangular Frame.—Many problems arise in which an analysis is required of the stresses in a framework of four sides without diagonal bracing, such framework depending for its stability upon the bending resistance of its various members. An example of such framework is the ordinary bridge portal, or the viaduct or elevated railroad bent in which diagonal bracing is omitted. Wind

bracing in tall buildings is frequently made of the portal or quadrangular form and occasionally high trestles are made of this type. Each transverse panel of a through bridge also forms such a framework, in which a correct determination of the stresses due to the load on the floor beam as well as lateral forces requires a consideration of the deformations of all the members of the frame.

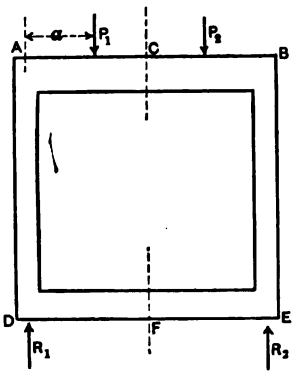

FIG. 33.

The stresses in a quadrangular frame are not statically determinate as they are dependent upon the deformations of the several members. A general solution of this problem will first be given, after which the analysis will be applied to several special cases.

274. General Solution.—Let *A B E D*, Fig. 33, be a complete rectangular frame supporting any loads, P_1, P_2, etc. The reactions, R_1 and R_2, are supposed to be determined by considering the structure as a whole, and the conditions of its supports. The problem is to determine the stresses in the frame.

The general method of solution used in the case of the arch with fixed ends can be advantageously applied here. The frame is cut at a convenient point, as at the centre, C, and the internal forces, M_o, V_o, and H_o, acting at this section treated as the unknown quantities. They are indicated in Fig. 34 in the direction which will be considered as positive. Then, selecting any other convenient section, as F, as the section of reference, assume this section to stand fast and treat the right and left half of the frame exactly as the two halves of the arch in Art. 154. In brief, express the deflections and changes of angle at C, of each half, with respect to the fixed section

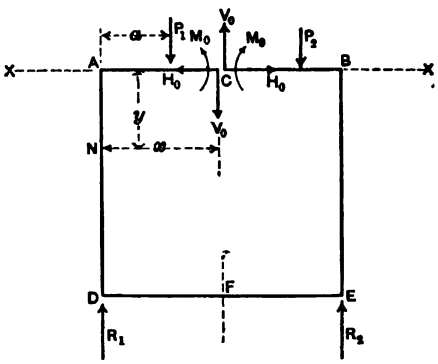

FIG. 34.

at F, by means of the general equations of Arts. 2 and 3. Then equate these functions for the two halves, thus deriving three equations from which the three unknowns, M_o, H_o, and V_o are found.

As in Art. 154, let M'_r and M'_l represent the bending moment at any section in the right and left portions respectively, due to the given external forces, M_r and M_l, the total bending moments, and x and y the co-ordinates of any section, measured from C, as origin, x to be considered as positive toward the right for the right half and toward the left for the left half. Let I = moment of inertia of the section in general. Then, since the horizontal and vertical components of the deflection at C, for the two halves must be equal, and likewise the angular change, we have, as in Art. 154, with due regard to sign, and considering E as constant,

$$\left.\begin{aligned} \int \frac{M_l x\,ds}{I} &= \int \frac{M_r x\,ds}{I} \\ \int \frac{M_l y\,ds}{I} &= -\int \frac{M_r y\,ds}{I} \\ \int \frac{M_l\,ds}{I} &= -\int \frac{M_r\,ds}{I} \end{aligned}\right\} \quad \ldots\ldots \quad (1)$$

For the left side,

$$M_l = M'_l + M_o + H_o y - V_o x.$$

For the right side,

$$M_r = M'_r + M_o + H_o y + V_o x.$$

Substituting in (1), we have for the general case, the following three equations between the unknowns M_o, H_o, and V_o,

$$\left(\int_l \frac{x\,ds}{I} - \int_r \frac{x\,ds}{I}\right) M_o + \left(\int_l \frac{xy\,ds}{I} - \int_r \frac{xy\,ds}{I}\right) H_o - V_o \int \frac{x^2\,ds}{I} = \int \frac{M'_r x\,ds}{I} - \int \frac{M'_l x\,ds}{I} \quad . (2)$$

$$M_o \int \frac{y\,ds}{I} + H_o \int \frac{y^2\,ds}{I} + \left(\int_r \frac{xy\,ds}{I} - \int_l \frac{xy\,ds}{I}\right) V_o = -\int \frac{M' y\,ds}{I} \quad (3)$$

$$M_o \int \frac{ds}{I} + H_o \int \frac{y\,ds}{I} + \left(\int_r \frac{x\,ds}{I} - \int_l \frac{x\,ds}{I}\right) V_o = -\int \frac{M'\,ds}{I} \quad \ldots \quad (4)$$

In any problem the numerical values of the various coefficients of M_o, H_o, and V_o should be first calculated, after which these equations are readily solved.

275. Symmetrical Frames.—For a frame symmetrical about a vertical axis, equations (2) to (4) become much simplified, the various functions of x and y for the left side being equal to similar functions for the right side. The several equations reduce to the following:

$$\left.\begin{aligned} V_0 \int_{\frac{1}{2}} \frac{x^2\,ds}{I} &= \tfrac{1}{2} \int \frac{M'_l\, x\, ds}{I} - \tfrac{1}{2} \int \frac{M'_r\, x\, ds}{I} \\ M_0 \int_{\frac{1}{2}} \frac{y\,ds}{I} + H_0 \int_{\frac{1}{2}} \frac{y^2\,ds}{I} &= -\tfrac{1}{2} \int \frac{M'\, y\, ds}{I} \\ M_0 \int_{\frac{1}{2}} \frac{ds}{I} + H_0 \int_{\frac{1}{2}} \frac{y\,ds}{I} &= -\tfrac{1}{2} \int \frac{M'\, ds}{I} \end{aligned}\right\} \quad . \quad . \quad (5)$$

In this expression, $\int_{\frac{1}{2}}$ signifies the integration for one-half only. Solving for H_0, V_0, and M_0 we derive as in Art. 154,

$$H_0 = \frac{\int_{\frac{1}{2}} \frac{ds}{I} \int \frac{M'\, y\, ds}{I} - \int_{\frac{1}{2}} \frac{y\,ds}{I} \int \frac{M'\, ds}{I}}{2\left[\left(\int_{\frac{1}{2}} \frac{y\,ds}{I}\right)^2 - \int_{\frac{1}{2}} \frac{ds}{I} \int_{\frac{1}{2}} \frac{y^2\,ds}{I}\right]} \quad . \quad . \quad (6)$$

$$V_0 = \frac{\int \frac{M'_l\, x\, ds}{I} - \int \frac{M'_r\, x\, ds}{I}}{2 \int_{\frac{1}{2}} \frac{x^2\,ds}{I}} \quad . \quad . \quad . \quad . \quad . \quad (7)$$

$$M_0 = -\frac{\int \frac{M'\, ds}{I} + 2\, H_0 \int_{\frac{1}{2}} \frac{y\,ds}{I}}{2 \int_{\frac{1}{2}} \frac{ds}{I}} \quad . \quad . \quad . \quad . \quad . \quad (8)$$

Inasmuch as each term contains a value of I, the result will be the same if, instead of using actual values, only relative values are employed. This is a more convenient method in the investigation of general problems in which the relative proportions of the various members may be assumed.

If the dimensions of a symmetrical frame be as shown in Fig. 35,

the values of the several integrals of the above equations, which do not involve M', are as follows (for one-half only):

Integral.	C to A	A to D	D to F
$\int \frac{ds}{I}$	$\frac{b}{2I_1}$	$\frac{h}{I_2}$	$\frac{b}{2I_3}$
$\int \frac{y\,ds}{I}$	0	$\frac{h^2}{2I_2}$	$\frac{bh}{2I_3}$
$\int \frac{y^2\,ds}{I}$	0	$\frac{h^3}{3I_2}$	$\frac{bh^2}{2I_3}$
$\int \frac{x^2\,ds}{I}$	$\frac{b^3}{24I_1}$	$\frac{b^2h}{4I_2}$	$\frac{b^3}{24I_3}$

The integrals involving M' depend upon the external loads. For a single load P, applied a distance a, from A, there will be

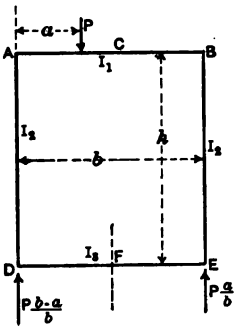

FIG. 35.

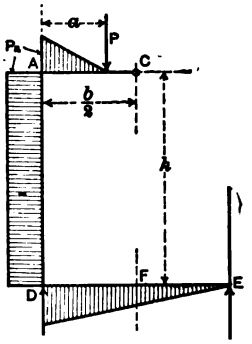

FIG. 36.

moments M', as shown in Fig. 36, and the various integrals are as follows:

Integral.	C to A	A to D	D to F	F to E
$\int \frac{M'\,ds}{I}$	$-\frac{Pa^2}{2I_1}$	$-\frac{Pah}{I_2}$	$-\frac{Pab}{2I_3}$	
$\int \frac{M'\,y\,ds}{I}$	0	$-\frac{Pah^2}{2I_2}$	$-\frac{Pabh}{2I_3}$	
$\int \frac{M'\,x\,ds}{I}$	$-\frac{Pa^2}{2I_1}\left(\frac{b}{2}-\frac{a}{3}\right)$	$-\frac{Pabh}{2I_2}$	$-\frac{5\,Pab^2}{48\,I_3}$	$-\frac{Pab^2}{48\,I_3}$

EXAMPLE.—Assume the following data (Fig. 35): $h = 150$ in.; $b = 120$ in.; $I_1 = 8{,}000$; $I_2 = 2{,}000$; $I_3 = 4{,}000$; $a = b/4 = 30$ in. It will be convenient, and lead to the same results, to call $I_2 = 1$; $I_3 = 2$; $I_1 = 4$.

We then have, for one-half of the frame,

$$\int \frac{ds}{I} = 15 + 150 + 30 = 195.$$

$$\int \frac{y\,ds}{I} = 11{,}250 + 4{,}500 = 15{,}750.$$

$$\int \frac{y^2\,ds}{I} = 1{,}125{,}000 + 675{,}000 = 1{,}800{,}000.$$

$$\int \frac{x^2\,ds}{I} = 18{,}000 + 540{,}000 + 36{,}000 = 594{,}000.$$

And for the entire frame,

$$\int \frac{M'\,ds}{I} = -P\,(112 + 4{,}500 + 900) = -5{,}512\,P.$$

$$\int \frac{M'\,y\,ds}{I} = -P\,(337{,}500 + 135{,}000) = -472{,}500\,P.$$

$$\int_l \frac{M'\,x\,ds}{I} - \int_r \frac{M'\,x\,ds}{I} = -P\,(5{,}625 + 270{,}000 + 22{,}500 - 4{,}500) = -293{,}625\,P.$$

Substituting in Eqs. (6), (7), and (8), we have,

$$H_o = \frac{195\,(-472{,}500) - 15{,}750\,(-5{,}512)}{2\,[(15{,}750)^2 - 195 \times 1{,}800{,}000]}\,P = +.0258\,P.$$

$$V_o = \frac{-344{,}250}{2 \times 594{,}000}\,P = -.247\,P.$$

$$M_o = -\frac{-5{,}512 + 2 \times .0258 \times 15{,}750}{2 \times 195}\,P = +12.05\,P.$$

276. Quadrangular Frames with Brackets.—Figs. 37 and 38 illustrate other arrangements with respect to the manner of applying the load. In Fig. 38 the moments M' in $A\,C$ and $A\,G$ are zero, and in $G\,D$ it is $+P\,a$. The general formulas given in Art. 274 apply directly to these cases, the only feature requiring notice being the values of the moment M'.

These forms are often used in highway bridges where sidewalks are supported on brackets.

277. Frame with Posts Fixed at Ends.—If the posts $A\,D$ and $B\,E$ are fixed at the lower end, Fig. 39, then the formulas above de-

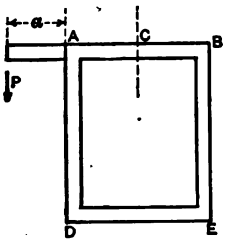

FIG. 37.

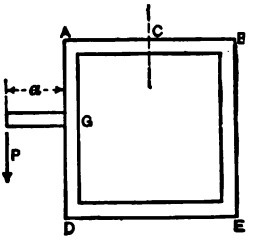

FIG. 38.

veloped will apply by making $I_3 = \infty$. For a single load P the integrals given in Art. 275 may be substituted directly in eqs. (6), (7), and (8),

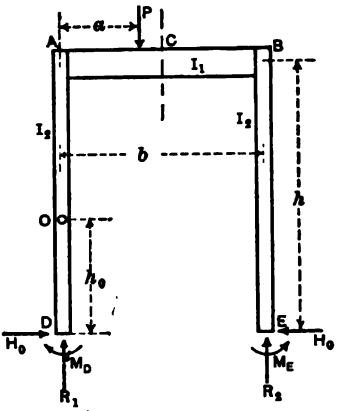

FIG. 39.

omitting values for member $D\,E$. By such substitution and reduction, there result the following values:

$$H_o = \frac{3\,P a\,(b-a)\,I_2}{2\,h^2 I_1 + 4\,b\,h\,I_2} \qquad (9)$$

$$V_o = -P\frac{a}{b}\left(1 - \frac{(b-a)\,(b-2\,a)\,I_2}{b^2 I_2 + 6\,b\,h\,I_1}\right) \qquad (10)$$

$$M_o = \frac{P a}{2}\left(1 - \frac{2\,(b-a)\,I_2}{h I_1 + 2\,b\,I_2}\right). \qquad (11)$$

Having the values of H_o, V_o, and M_o for section C, the values of the moments and stresses at any section are readily found. Thus at A we have $M_A = M_o - V_o \frac{b}{2} - P a$; at D, $M_D = M_o - V_o \frac{b}{2} - P a + H_o h$; etc.

For two loads P, symmetrically placed, $V_o = 0$, and H_o and M_o are twice the values given by (9) and (11). Moments at A and D are then

$$M_A = - \frac{2 P a (b - a) I_2}{h I_1 + 2 b I_2} \quad . \quad . \quad . \quad . \quad . \quad (12)$$

$$M_D = + \frac{P a (b - a) I_2}{h I_1 + 2 b I_2} \quad . \quad . \quad . \quad . \quad . \quad (13)$$

The point of inflection, O, is located a distance above the base equal to

$$h_o = \frac{h}{3} \quad . \quad . \quad . \quad . \quad . \quad . \quad . \quad . \quad (14)$$

278. Frame with Posts Hinged at One End.—This case is solved by placing the horizontal deflection of E with respect to D equal to

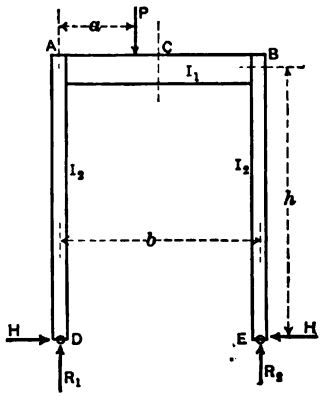

FIG. 40.

zero, or, what is the same thing, treating the forces H as redundant forces. In either case we have $\int \frac{M' m \, ds}{E I} + H \int \frac{m^2 \, ds}{E I} = 0$, in which M' is the moment due to the load P, and m is the moment due to a

value of H equal to one unit. This reduces to the same general expression developed for the two-hinged arch:

$$H = \frac{\int \frac{M' y\, ds}{I}}{\int \frac{y^2\, ds}{I}} \quad . \quad . \quad . \quad . \quad . \quad . \quad . \quad (15)$$

The integrals are as follows:

Integral.	D to A	A to B	B to E
$\int \frac{y^2\, ds}{I}$	$\frac{h^3}{3 I_2}$	$\frac{b\, h^2}{I_1}$	$\frac{h^3}{3 I_2}$
$\int \frac{M' y\, ds}{I}$	0	$\frac{P\, a\, (b-a)\, h}{2 I_1}$	0

Substituting in (15), we have

$$H = \frac{3\, P\, a\, (b - a)\, I_2}{4\, h^2\, I_1 + 6\, b\, h\, I_2} \quad . \quad . \quad . \quad . \quad . \quad . \quad (16)$$

The value of H being known, the bending moment at any section is easily found.

EXAMPLE.—Let Fig. 41 represent an elevated railway bent with the dimensions as shown. Let $I_1 = 50{,}000$; $I_2 = 640$; area of column $= A_2 =$

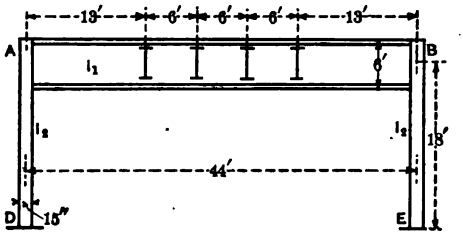

FIG. 41.

20 sq. in.; width of column = 15 in. Calculate the bending moments and fibre stresses at A and D, due to four loads of 60,000 lbs. applied as shown.

(*a*) *Fixed Ends.*—Eq. (12) may be used, calculating the term $a\ (b - a)$ for the two symmetrical pairs of loads. There results:

$M_A = -\ 846{,}600$ in. lbs.; $f_a = 9{,}960$ lbs. per sq. in.
$M_D = +\ 423{,}300$ in. lbs.; $f_d = 4{,}980$ lbs. per sq. in.

The direct stress in the columns is equal to 120,000/20 = 6,000 lbs. per sq. in. In this case therefore the bending stress is greater than the direct stress.

(*b*) *Hinged Ends.*—Use eq. (16), giving $H = 1{,}500$ lbs. Then $M_A = 1{,}500 \times 18 \times 12 = 324{,}000$ in. lbs.; and $f_a = 3{,}850$ lbs. per sq. in.

It is to be noted that in both cases the bending moments are nearly proportional to the value of I_2, and that having the bending moments the value of f is proportional to the width of the member. Hence it may be said that the fibre stress in such a case is approximately proportional to $I_2 c$, or the moment of inertia times the width. For low stresses, therefore, a relatively narrow column is very advantageous.

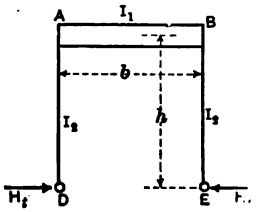

FIG. 42.

279. Temperature Stresses.—Where one side of the frame is fixed in length, as in the preceding two cases, changes of temperature will cause stresses in the structure. These are found by placing the deflection of E with respect to D equal to the change of length of $A\,B$ due to change of temperature. For hinged ends, Fig. 42, the deflection is $\Delta_t = \int \frac{M\,y\,ds}{EI} = H \int \frac{y^2\,ds}{EI}$. This reduces to

$$\Delta_t = \frac{H\,h^2}{E}\left(\frac{2\,h}{3\,I_2} + \frac{b}{I_1}\right). \quad . \quad . \quad . \quad . \quad . \quad . \quad (17)$$

Let ω = coefficient of expansion. Then $\Delta_t = \omega\,t\,b$ and we have for temperature changes,

$$H_t = \frac{E\,\omega\,t\,b}{h^2\left(\frac{2\,h}{3\,I_2} + \frac{b}{I_1}\right)}. \quad . \quad . \quad . \quad . \quad . \quad . \quad (18)$$

For fixed ends at D and E, Fig. 43, we may determine the total angular change $\Delta\,\varphi$ from D to E, and the total horizontal movement $\Delta\,x$, and write $\Delta\,\varphi = 0$ and $\Delta\,x = -\Delta_t = -\omega\,t\,b$. As in Art. 274, we have

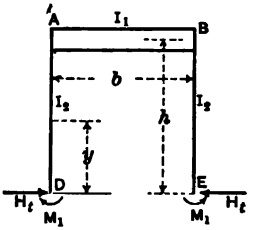

FIG. 43.

$$\Delta\,\varphi = \int \frac{M\,ds}{EI} \text{ and } \Delta\,x = \int \frac{M\,y\,ds}{EI}.$$

Let M_1 = moment at D and E. Then $M = M_1 - H_t y$. Substituting this value of M in the above integrals, we have

$$M_1 \int \frac{ds}{EI} - H_t \int \frac{y\,ds}{EI} = 0.$$

$$M_1 \int \frac{y\,ds}{EI} - H_t \int \frac{y^2\,ds}{EI} = -\Delta_t.$$

Solving for H_t and M_1, we derive

$$H_t = \frac{\Delta_t \int \frac{ds}{EI}}{\int \frac{ds}{EI} \int \frac{y^2\,ds}{EI} - \left(\int \frac{y\,ds}{EI}\right)^2} \quad \ldots \quad (19)$$

$$M_1 = \frac{H_t \int \frac{y\,ds}{I}}{\int \frac{ds}{I}} \quad \ldots \quad (20)$$

Expressing the several integrals in terms of the dimensions of the frame as given in Fig. 43, we have

Integral.	D to A	A to B	B to E
$\int \frac{ds}{I}$	$\frac{h}{I_2}$	$\frac{b}{I_1}$	$\frac{h}{I_2}$
$\int \frac{y\,ds}{I}$	$\frac{h^2}{2I_2}$	$\frac{bh}{I_1}$	$\frac{h^2}{2I_2}$
$\int \frac{y^2\,ds}{I}$	$\frac{h^3}{3I_2}$	$\frac{bh^2}{I_1}$	$\frac{h^3}{3I_2}$

Substituting and reducing, we have,

$$H_t = \frac{3EI_2(bI_2 + 2hI_1)\,\omega t b}{h^3(2bI_2 + hI_1)} \quad \ldots \quad (21)$$

$$M_1 = \frac{3EI_2(bI_2 + hI_1)\,\omega t b}{h^2(2bI_2 + hI_1)} \quad \ldots \quad (22)$$

$$M_A = M_1 - H_t h = -\frac{3EI_1I_2\omega t b}{h(2bI_2 + hI_1)} \quad \ldots \quad (23)$$

The distance of the point of inflection above the base is

$$h_o = \frac{M_1}{H_t} = h\,\frac{b\,I_2 + h\,I_1}{b\,I_2 + 2\,h\,I_1}. \quad . \quad . \quad . \quad . \quad . \quad (24)$$

EXAMPLE.—Let it be required to calculate the temperature stresses in the bent of Art. 278 for an increase of temperature of 50 degrees, the coefficient of expansion being .0000065.

a. Fixed Ends.—The value of $\omega\,t\,b$ = .0000065 × 50 × 44 × 12 = 0.1716 in. Then by Eq. (22) M_d = 206,000 in. lbs.; and f_d = 2,410 lbs. per sq. in. From (23) M_a = − 199,000 in. lbs., and f_a = 2,330 lbs. per sq. in.

b. Hinged Ends.—Eq. (18) gives H_t = 467 lbs., and hence M_a = 467 × 18 × 12 = 101,400 in. lbs., and f_a = 1,182 lbs. per sq. in.

Temperature stresses are about double for fixed ends as for hinged ends. The values would be exactly double if I_1 were indefinitely large.

280. Effect of Lateral Forces.—Fig. 44 represents a quadrangular frame, symmetrical about a vertical axis and acted upon by the horizontal force P, applied at B. The reactions are assumed to be applied as shown. It is required to determine the stresses in the frame. The

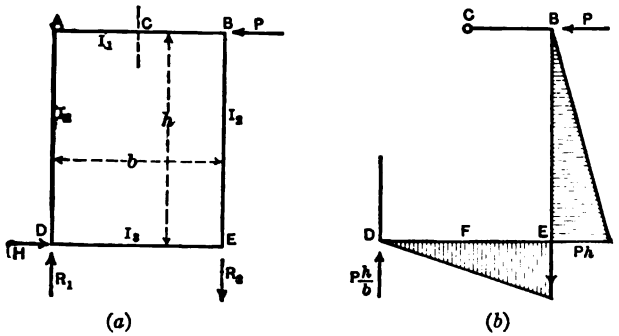

FIG. 44.

general solution of the problem is the same as given in Art 274. A section is taken at C and the values of H_o, V_o, and M_o determined by the general formulas of Art. 274. The moment diagram for the moments M' are shown in Fig. 44 (*b*). The values of the several integrals involving M' are as follows:

Integrals.	C to B	B to E	E to F	F to D
$\int \frac{M' ds}{I}$	0	$-\frac{P h^2}{2 I_2}$	$-\frac{P b h}{2 I_3}$	
$\int \frac{M' y ds}{I}$	0	$-\frac{P h^2}{3 I_2}$	$-\frac{P h^2 b}{2 I_3}$	
$\int \frac{M' x ds}{I}$	0	$-\frac{P h^2 b}{4 I_2}$	$-\frac{5 P b^2 h}{48 I_3}$	$-\frac{P b^2 h}{48 I_3}$

Substituting in eqs. (6), (7), and (8), we derive the following:

$$M_0 = 0. \quad . \quad . \quad . \quad . \quad . \quad . \quad . \quad . \quad . \quad . \quad . \quad . \quad (25)$$

$$V_0 = -\frac{P\left(\frac{b h^2}{4 I_2} + \frac{b^2 h}{12 I_3}\right)}{2\left[\frac{b^3}{24 I_1} + \frac{b^2 h}{4 I_2} + \frac{b^3}{24 I_3}\right]}. \quad . \quad . \quad . \quad . \quad (26)$$

$$H_0 = \frac{P}{2}. \quad . \quad . \quad . \quad . \quad . \quad . \quad . \quad . \quad . \quad . \quad . \quad . \quad (27)$$

The important results are, that, where the members $A D$ and $B E$ are alike, $M_0 = 0$ and $H_0 = \frac{P}{2}$, that is, the point C is a point of inflection and the value of H_0 is $\frac{P}{2}$, which signifies that the lateral pressure, P, is carried equally by the two sides of the frame. It also follows that the point of inflection in $D E$ is at the centre, F, and the value of the shear at this point is found by interchanging I_3 and I_1 in eq. (26). It is

$$V_F = -\frac{P\left(\frac{b h^2}{4 I_2} + \frac{b^2 h}{12 I_1}\right)}{2\left[\frac{b^3}{24 I_1} + \frac{b^2 h}{4 I_2} + \frac{b^3}{24 I_3}\right]}. \quad . \quad . \quad . \quad . \quad (28)$$

The sum of $V_0 + V_F$ must equal $R_1 = \frac{P h}{b}$, as will be found by adding (27) and (28).

If $I_1 = I_3$, then $V_o = V_F = \frac{P\,h}{2\,b}$.

The forces acting on one-half the frame are clearly shown in Fig. 45.

If the posts are fixed at the base, then $I_3 = \infty$, and we have

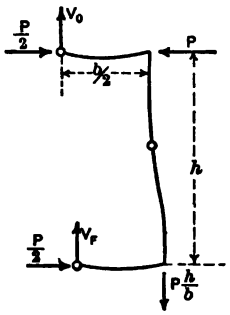

FIG. 45.

$$V_o = -P\,\frac{3\,h^2 I_1}{b^2 I_2 + 6\,b\,h\,I_1}. \quad . \quad (29)$$

The point of inflection in the vertical post is found by placing $\frac{V_o\,b}{2} + \frac{P\,(h - h_o)}{2} = 0$, where h_o is the distance of this point above the base.

281. Partially Trussed Portal Frames.—Frames of the type shown in Fig. 46 are partly trussed and partly a framework of beams. Members $F\,G$ and $H\,K$ are hinged at their ends, and hinges exist at A and B, and may or may not exist at D and E. As in Art. 280, there will be a point of inflection at the centre C, and the compression at C will be $\frac{P}{2}$. The horizontal reactions at D and E will each be $\frac{P}{2}$. If the

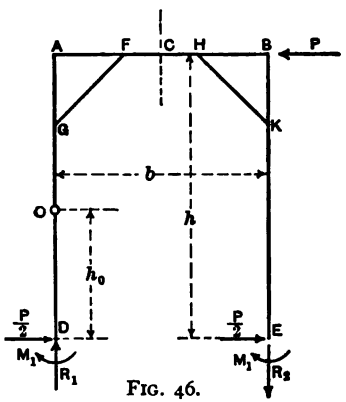

FIG. 46.

posts are fixed at D and E, there remain to be determined the moments M_1 at these points, or the distance h_o of the point of inflection above D. If the posts are hinged, all external forces become known and the problem is solved as explained in Part I. The influence of the deformations due to direct stresses will be neglected as it is very small in any case.

In the solution of this problem it is sufficient to consider one-half only, as shown in Fig. 47. The problem is solved by the application of the theory of redundant members. A convenient form of solution

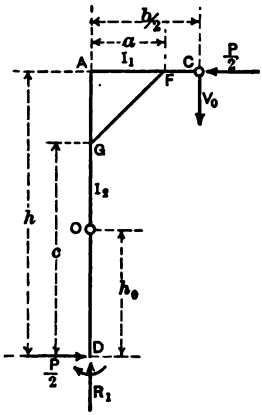

FIG. 47.

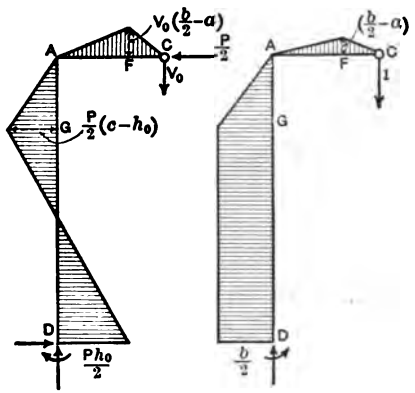

Moments M Moments m.

FIG. 48.

is to place the deflection of the point C equal to zero, as is evident from the symmetry of conditions. The general expression for this deflection, neglecting the effect of direct stress, is $\Delta = \Sigma \int \frac{M\,m\,ds}{E\,I}$, in which M is the actual moment at any section and m is the moment due to unit load acting at C. Fig. 48 shows the moment diagrams for moments M and m. The values of M and m, and of the several integrals, are as follows, origins taken at C, A, and D:

Quantity.	C to F	A to F	A to G	G to D
M	$-V_0 x$	$-V_0 \frac{\left(\frac{b}{2}-a\right)}{a} x$	$-\frac{P(c-h_0)x}{2(h-c)}$	$\frac{P(h_0-x)}{2}$
m	$-x$	$-\frac{\frac{b}{2}-a}{a} x$	$-\frac{bx}{2(h-c)}$	$-\frac{b}{2}$
$M\,m$	$V_0 x^2$	$V_0\left(\frac{\frac{b}{2}-a}{a}\right)^2 x^2$	$\frac{Pb(c-h_0)x^2}{4(h-c)^2}$	$-\frac{Pb(h_0-x)}{4}$
$\int \frac{M\,m\,ds}{I}$	$\frac{V_0\left(\frac{b}{2}-a\right)^2}{3I_1}$	$\frac{V_0\left(\frac{b}{2}-a\right)^2 a}{3I_1}$	$\frac{Pb(c-h_0)(h-c)}{12I_2}$	$\frac{Pbc(c-2h_0)}{8I_2}$

Adding the several integrals, substituting $V_o = \frac{H(h - h_o)}{b}$ and solving for h_o, we derive

$$h_o = \frac{h(b - 2a)^2 I_2 + 2bc(c + 2h) I_1}{(b - 2a)^2 I_2 + 4b(2c + h) I_1}. \quad . \quad . \quad (30)$$

The value of h_o being known, the stresses in the portal are found as for the case of hinged ends, the point of inflection O being taken as the hinge. For such cases as shown in Fig. 49, the solution will be

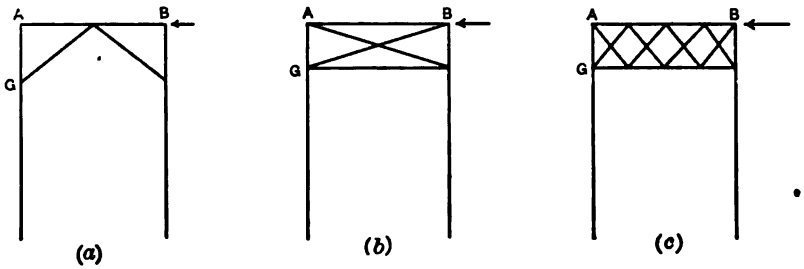

FIG. 49.

reached from eq. (30), by placing $I_1 = \infty$; or, what is the same thing, by placing the lateral deflection of the two points A and G equal. Dividing both numerator and denominator of (30) by I_1, and then placing $I_1 = \infty$, we derive

$$h_o = \frac{c(c + 2h)}{2(2c + h)} \quad . \quad . \quad . \quad . \quad . \quad . \quad (31)$$

which is the same value as deduced in Art. 199, Part I, eq. (29).

282. Frames with Inclined Posts.—The general methods of Art. 274 are obviously applicable to such frames as illustrated in Fig. 50. If the frame is symmetrical about a vertical axis the effect of a horizontal force P is similar to that in a rectangular frame. The centre points of members $A\,B$ and $D\,E$ are points of inflection, and the direct stress in $A\,B$ is $\frac{P}{2}$.

Placing the deflection of C with respect to F equal to zero (Fig. 51), enables the values of V_1 and V_2 to be determined in the same manner

as in Art. 280. This deflection is most readily found by the general expression $\Delta = \int \frac{M x\, ds}{E I}$, where x is the abscissa measured from the origin C. For member $C A$, $M = V_1 x$ and $\int \frac{M x\, ds}{I} = \frac{V_1 b_1^3}{24 I_1}$; likewise for $F D$, $\int \frac{M x\, ds}{I} = -\frac{V_2 b_2^3}{24 I_3}$, writing this deflection as

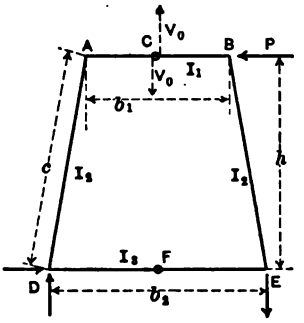

FIG. 50.

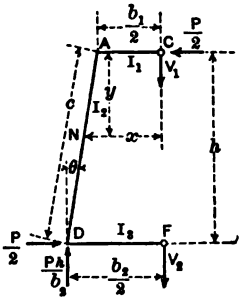

FIG. 51.

minus, since it tends to diminish the deflection of C relative to F. For the member $A D$ the integral $\int \frac{M x\, ds}{I}$ is found as follows: For any point N, the moment $M = V_1 x - \frac{P y}{2}$. Also we have $ds = \frac{dx}{\sin \theta} = \frac{2c}{b_2 - b_1} . dx$, and $y = \left(x - \frac{b_1}{2}\right) \cot \theta = \frac{h}{b_2 - b_1}(2x - b_1)$. We then have for $A D$,

$$\int \frac{M x\, ds}{I} = \frac{2 V_1 c}{(b_2 - b_1) I_1} \int_{\frac{b_1}{2}}^{\frac{b_2}{2}} x^2 dx - \frac{P h c}{I_2 (b_2 - b_1)^2} \int_{\frac{b_1}{2}}^{\frac{b_2}{2}} (2x^2 - b_1 x)$$

$$= \frac{V_1 c (b_2^2 + b_1 b_2 + b_1^2)}{12 I_2} - \frac{P h c (2 b_2 + b_1)}{24 I_2}.$$

We therefore have, after multiplying through by 12,

$$\frac{V_1 c (b_2^2 + b_1 b_2 + b_1^2)}{I_2} + \frac{V_1 b_1^3}{2 I_1} - \frac{V_2 b_2^3}{2 I_3} = \frac{P h c (2 b_2 + b_1)}{2 I_2}. \quad (32)$$

Also

$$V_1 + V_2 = \frac{P h}{b_2} \quad . \quad . \quad . \quad . \quad . \quad . \quad (33)$$

from which V_1 and V_2 are readily found.

283. Portal Frames of Multiple Stories.—In building construction, and occasionally in other structures, quadrangular lateral bracing is used consisting of several such frames placed one above the other or side by side (Fig. 52). The analysis of such frames may be made in

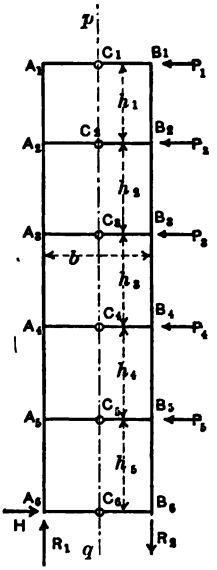

FIG. 52.

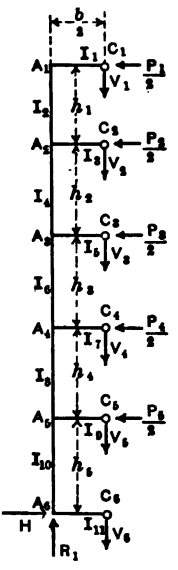

FIG. 53.

the same manner as for a single quadrangle. A section $p\,q$ is taken through the centre, and at each point C, there are three unknowns, M, V, and H. The necessary equations are obtained by writing out for each story the same relations as expressed in Art. 274, thus giving three equations for each section, corresponding to the number of unknowns.

If the framework is symmetrical about the section $p\,q$, as is usually the case, then the points of inflection of the several transverse beams, $A\,B$, will be at the centre point C, and the several values of H will be one-half the lateral force, P, applied at the respective level. There remain to be determined then only the shears, V, at the sections C. The necessary equations are obtained by placing equal to zero the deflection of C_1 with respect to C_2, also that of C_2 with respect to C_3, etc. This gives five equations in the structure shown. The sixth is found by taking moments of all the forces about A_6, giving

$$\Sigma V \frac{b}{2} = \tfrac{1}{2} [P_1 (h_1+h_2+h_3+h_4+h_5) + P_2 (h_2+h_3+h_4+h_5) + \text{etc.}]$$

The deflections are very easily expressed in terms of V and P by use of the general expression $\Delta_y = \int \frac{M x\, dx}{E I}$. The necessary equations will be given here for a five-story frame, using the notation shown in Fig. 53.

For the deflection of C_1 relative to C_2, we need consider only the members $C_1 A_1 A_2 C_2$. Using C_1, A_1, and C_2 as origins, the moment in $C_1 A_1 = V_1 x$; that in $A_1 A_2 = V_1 \frac{b}{2} - \frac{P_1}{2} y$, and in $A_2 C_2$ it is $- V_2 x$, considering as plus a moment which contributes to the downward deflection of C_1 relative to C_2. The value of the integrals $\int \frac{M x\, dx}{I}$ will be as follows:

$$\text{for } C_1 A_1, \quad \frac{V_1 b^3}{24 I_1};$$

$$\text{for } A_1 A_2, \quad \frac{V_1 b^2 h_1}{4 I_2} - \frac{P_1 h_1^2 b}{8 I_2};$$

$$\text{for } A_2 C_2, - \frac{V_2 b^3}{24 I_3};$$

whence we have

$$\frac{V_1 b h_1}{I_2} + \frac{V_1 b^3}{6 I_1} - \frac{V_2 b^2}{6 I_3} = \frac{P_1 h_1^2}{2 I_2}. \quad . \quad . \quad . \quad . \quad (34)$$

For the deflection of C_2 with respect to C_3, consider only the frame $C_2 A_2 A_3 C_3$. The moment in $C_2 A_2 = V_2 x$; in $A_2 A_3$ it is $(V_1 + V_2) \frac{b}{2} - \frac{P_1}{2} h_1 - \frac{P_1 + P_2}{2} y$; and in $A_3 C_3$ it is $- V_3 x$. Except for the member $A_2 A_3$ the values are similar to those in the first story. The value of $\int \frac{M x\, dx}{I}$ for $A_2 A_3$ is

$$(V_1 + V_2) \frac{b^2 h_2}{4 I_4} - \frac{P_1 h_1 h_2 b}{4 I_4} - \frac{(P_1 + P_2) h_2^2 b}{8 I_4}.$$

We then derive the expression, corresponding to (34),

$$(V_1 + V_2) \times \frac{b\,h_2}{I_4} + \frac{V_2 b^2}{6\,I_3} - \frac{V_3 b^2}{6\,I_5} = \frac{(P_1 + P_2)\,h_2^2 + 2\,P_1 h_1 h_2}{2\,I_4}. \quad (35)$$

For the next section, with origin at C_3, the moment in A_3A_4 is equal to $(V_1 + V_2 + V_3)\,\frac{b}{2} - \frac{P_1(h_1 + h_2) + P_2 h_2}{2} - \frac{(P_1 + P_2 + P_3)\,y}{2}$.

We derive then, as before,

$$(V_1+V_2+V_3)\frac{bh_3}{I_6} + \frac{V_3b^2}{6\,I_5} - \frac{V_4b^2}{6\,I_7} = \frac{(P_1 + P_2 + P_3)\,h_3^2 + 2\,[P_1(h_1 + h_2) + P_2h_2]\,h_3}{2\,I_6}. \quad (36)$$

And for the lower story we derive in a similar manner:

$$(V_1+V_2+V_3+V_4+V_5)\frac{bh_5}{I_{10}} + \frac{V_5b^2}{6I_9} - \frac{V_6b^2}{6I_{11}} =$$
$$\frac{(P_1+P_2+P_3+P_4+P_5)h_5^2 + 2[P_1(h_1+\ldots h_4) + P_2(h_2+\ldots h_4) + P_3(h_3+h_4) + P_4h_4]h_5}{2\,I_{10}}. \quad (37)$$

Then taking moments about A_6, we have

$$(V_1+\ldots+V_6)\frac{b}{2} = \frac{P_1(h_1+\ldots+h_5) + P_2(h_2+\ldots+h_5) + P_3(h_3+h_4+h_5) + P_4(h_4+h_5) + P_5h_5}{2} \quad (38)$$

These six linear equations between the values of V are readily solved after substituting numerical coefficients. The values of V being known, the moments are readily found at any section. For more numerous stories additional equations are easily written out following the form of eq. (37). If the lower ends of the posts are fixed, then the value of I for the lower strut is ∞. If hinged, then the value of V_6 for the lower strut is zero in eq. (37), and equations of deflection are written out for all stories above the lowest.

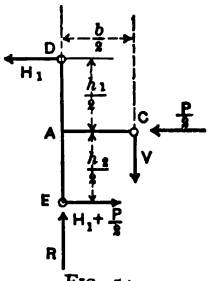

FIG. 54.

For a large number of stories an exact analysis becomes quite laborious. Approximate results may be reached by assuming that the point of inflection of the columns is midway between the lateral struts. For any particular joint the forces acting are then as shown in Fig. 54. H_1 represents half the sum of all the lateral forces above this story, and $\frac{P}{2}$ the lateral force applied at this section. Taking

moments about E, we have $V\frac{b}{2} = \frac{H_1(h_1+h_2)}{2} + \frac{P h_2}{4}$, whence

$$V = \frac{2H_1(h_1+h_2) + P h_2}{2b}. \quad . \quad . \quad . \quad . \quad (39)$$

284. Portal-Braced Towers with Inclined Posts.—The Kinzua Viaduct, constructed in 1900, is of the type shown in Fig. 55. The

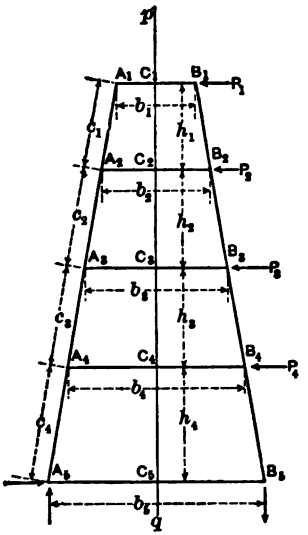

FIG. 55.

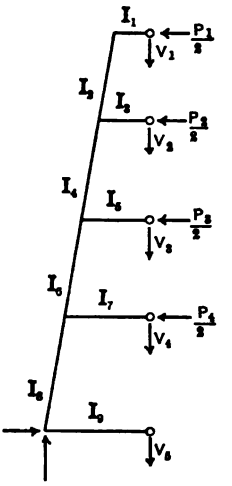

FIG. 56.

lateral rigidity is secured by relatively deep struts riveted to the main columns of the towers. The analysis of such a structure may be made in the manner explained in the preceding article. Points C_1, C_2, etc., are points of inflection, and their deflection with respect to each other will be zero. Fig. 56 represents one-half the structure. The equations will vary from those of the preceding article on account of the inclined posts, in the same manner as those of Art. 282 differ from those of Art. 275. For the struts, the integrals are of the same form as in Art. 275. For the posts they are different.

As deduced in Art. 282 the integral $\int \frac{M x\, dx}{I}$ for $A_1 A_2$ is

$$\frac{V_1 c_1 (b_1^2 + b_1 b_2 + b_2^2)}{12 I_2} - \frac{P_1 h_1 c_1 (2 b_2 + b_1)}{24 I_2},$$

and for the top story the equation is the same as eq. (32) of Art. 282. For the second story the integrals for $C_2 A_2$ and $C_3 A_3$ are equal to $\frac{V_2 b_2^3}{24 I_3}$ and $-\frac{V_3 b_3^3}{24 I_5}$ respectively. For $A_2 A_3$ the effect of V_1 and V_2 is the same as that of a force $V_1 + V_2$ acting at C_2, and is found by substituting $V_1 + V_2$ for V_1 in the expression above, and changing subscripts. It is $\frac{(V_1 + V_2)\, c_2\, (b_2^2 + b_2 b_3 + b_3^2)}{12\, I_4}$. For the horizontal forces $\frac{P_1}{2}$ and $\frac{P_2}{2}$, their effect on $A_2 A_3$ is the same as a single force $\frac{P_1 + P_2}{2}$ applied at C_2, together with a constant moment equal to $\frac{P_1 h_1}{2}$. The former is equal to $\frac{(P_1 + P_2)\, h_2 c_2\, (2 b_3 + b_2)}{24\, I_4}$. The constant moment $\frac{P_1 h_1}{2}$ applied in $A_2 A_3$ is at an average distance x from C_2 equal to $\frac{b_2 + b_3}{4}$, hence for this part $\int \frac{M x\, dx}{I} = \frac{P_1 h_1 c_2 (b_2 + b_3)}{8 I_4}$. After multiplying through by 12 the equation for the second story becomes then

$$\frac{(V_1 + V_2)\, c_2\, (b_2^2 + b_2 b_3 + b_3^2)}{I_4} + \frac{V_2 b_2^3}{2 I_3} - \frac{V_3 b_3^3}{2 I_5} = \frac{(P_1 + P_2)\, h_2 c_2\, (2 b_3 + b_2) + 3 P_1 h_1 c_2\, (b_2 + b_3)}{2 I_4} \quad . \quad (40)$$

For the third story the equation is

$$\frac{(V_1 + V_2 + V_3)\, c_3\, (b_3^2 + b_3 b_4 + b_4^2)}{I_6} + \frac{V_3 b_3^3}{2 I_5} - \frac{V_4 b_4^3}{2 I_7} = \frac{(P_1 + P_2 + P_3) h_3 c_3 (2 b_4 + b_3) + 3[P_1 (h_1 + h_2) + P_2 h_2] c_3 (b_3 + b_4)}{2 I_6} \quad . \quad (41)$$

etc. etc. etc.

Then from moments about A_5, we have

$$V_1 + V_2 + V_3 + V_4 + V_5 = \frac{P_1 (h_1 + \ldots h_4) + P_2 (h_2 + \ldots h_4) + P_3 (h_3 + h_4) + P_4 h_4}{b_5} \quad . \quad (42)$$

EXAMPLE.—The Kinzua Viaduct. (Trans. Am. Soc. C. E., Vol. 46, 1901.) Fig. 57 represents a section of the Kinzua Viaduct, at a point of maximum

height, where five stories are employed. The dimensions *c.* to *c.* are as shown and also the values of the several moments of inertia.

The posts are assumed as fixed at the base, which is equivalent to assuming $I_{11} = \infty$

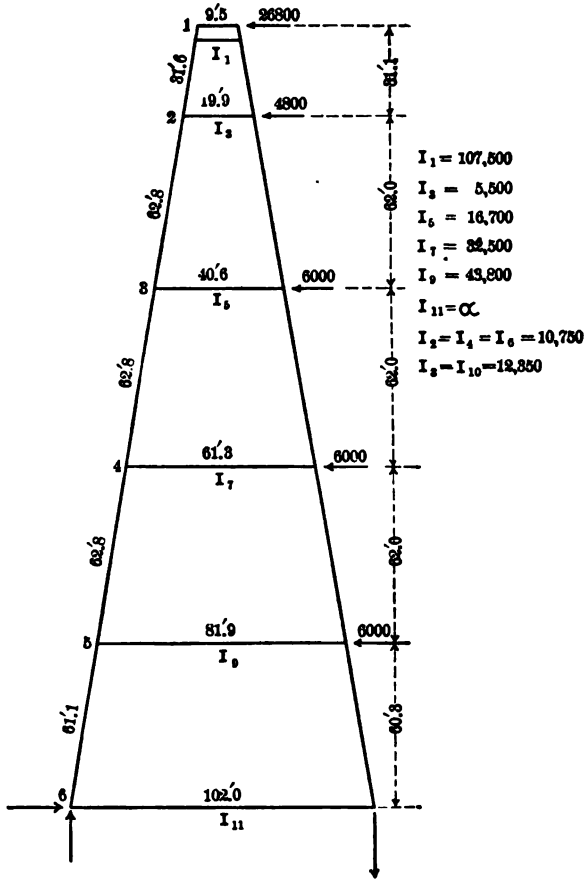

FIG. 57.

For the top story we have, by substituting in (32),

$$\frac{V_1 \times 31.6(9.5^2 + 9.5 \times 19.9 + 19.9^2)}{10,750} + \frac{V_1 \times 9.5^3}{2 \times 107,500} - \frac{V_2 \times 19.9^3}{2 \times 5,500} = \frac{26,800 \times 31.1 \times 31.6(2 \times 19.9 + 9.5)}{2 \times 10,750}$$

or

$$1.989\, V_1 - 0.716\, V_2 = 60,500. \quad . \quad . \quad . \quad . \quad . \quad (a)$$

Then from (40) we have

$$16.68\,V_1 + 17.40\,V_2 - 2.005\,V_3 = 1{,}021{,}000. \quad . \quad . \quad . \quad (b)$$

In a similar manner, for the 3d, 4th, and 5th stories we have

$$46.1\,V_1 + 46.1\,V_2 + 48.11\,V_3 - 3.54\,V_4 = 3{,}602{,}000. \quad (c)$$
$$78.65\,V_1 + 78.65\,V_2 + 78.65\,V_3 + 82.19\,V_4 - 6.26\,V_5 = 7{,}163{,}000. \quad (d)$$
$$126.0\,V_1 + 126.0\,V_2 + 126.0\,V_3 + 126.0\,V_4 + 132.26\,V_5 = 12{,}785{,}000. \quad (e)$$

(V_6 does not appear here as $I_{11} = \infty$).

In eliminating, note that V_5 may be eliminated from the last two equations, then V_4 from the resulting equation combined with (*c*), then V_3 and V_2, getting finally the value of V_1. Then by substitution the other values are readily found. The results are,

$V_1 = 38{,}900$ lbs., $V_4 = 12{,}400$ lbs.,
$V_2 = 23{,}400$ lbs., $V_5 = 9{,}900$ lbs.
$V_3 = 16{,}300$ lbs.,

These agree very closely with those given by Grimm in Trans. Am. Soc. C. E., Vol. 46, p. 32, calculated from the theory of least work.

If the posts were hinged at the base, then eq. (*e*) would no longer hold good. In its place we would make use of eq. (42), taking moments about the foot of the post.

285. Deflection of Quadrangular Frames.—The relative rigidity of quadrangular frames, or portals, as compared with full diagonal bracing is a matter of some importance. In any given case the deflection of such a frame is readily found from the general formula, $\Delta = \Sigma \int \frac{M\,m\,ds}{E\,I}$, where m is the moment due to a one-pound load acting at the point whose deflection is desired. General formulas are unwieldy except in simple cases. Such a case is that of the symmetrical frame subjected to a lateral force as discussed in Art. 280. A comparison of its deflection with that of a fully braced frame will be instructive.

The lateral deflection of the frame of Art. 280 can be calculated by considering the lateral deflection of point C with respect to F, of the half-frame as shown in Fig. 58. Let M_1 = moment at A due to the lateral force, and M_2 = moment at D. The moment in $A\,D$, at any point distant x from A, will be $M = M_1 + (M_2 - M_1)\,\frac{x}{h}$

$= M_1\left(1 - \frac{x}{h}\right) + M_2\frac{x}{h}$. The moment in $D\,F$ at any point distant x from $F = M_2\frac{2x}{b}$. For a one-pound load applied horizontally at C,

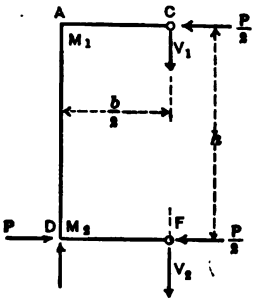

FIG. 58.

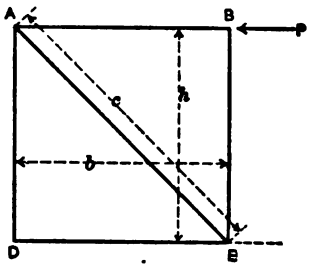

FIG. 59.

the moment in $A\,C = 0$, that in $A\,D = m = x$; and that in $D\,F = m = \frac{2hx}{b}$. The integrals $\int\frac{M\,m\,dx}{I}$ are then as follows:

$$\text{For } A\,D, \quad M_1\frac{h^2}{6\,I_2} + M_2\frac{h^2}{3\,I_2}.$$

$$\text{For } D\,F, \quad M_2\frac{b\,h}{6\,I_3}.$$

The deflection is, therefore,

$$\Delta_1 = \frac{h}{6E}\left[(M_1 + 2\,M_2)\frac{h}{I_2} + M_2\frac{b}{I_3}\right]. \quad . \quad . \quad . \quad (43)$$

For a fully braced rectangular frame (Fig. 59), the deflection is found from the formula $\Delta = \Sigma\frac{S\,u\,l}{E\,A}$. Assuming approximately that the section of the diagonal is small as compared to the other members of the frame, we derive the value

$$\Delta_2 = \frac{S\,(h^2 + b^2)}{E\,A\,b} \quad . \quad . \quad . \quad . \quad . \quad . \quad . \quad (44)$$

in which S is the total stress in the diagonal due to the load P.

To compare the relative values of Δ in (43) and (44), suppose that $b = h$, and $I_2 = I_3$. Then $M_1 = M_2$. Also let $S/A = s =$

working stress in the diagonal of Fig. 59, and let f = maximum fibre stress in the members of Fig. 58, due to the moment M_1, and let c = the half width of members of Fig. 58 = distance from neutral axis to extreme fibre. Then in eq. (43), $\frac{M}{I} = f/c$, and hence $\Delta_1 = \frac{2h^2 f}{3Ec}$. And in (44) $\Delta_2 = \frac{2hs}{E}$. The ratio of the two values is

$$\frac{\Delta_1}{\Delta_2} = \frac{hf}{3cs} \quad . \quad . \quad . \quad . \quad . \quad . \quad . \quad . \quad (45)$$

Generally the adopted working stress f, for lateral forces, will be much less than s. Suppose $f/s = 1/4$, then

$$\frac{\Delta_1}{\Delta_2} = \frac{h}{12c} \quad . \quad . \quad . \quad . \quad . \quad . \quad . \quad . \quad (46)$$

In this case, therefore, the deflections of the two forms will be equal if the half width, c, of the members, is equal to 1/12 the height of the panel. Generally the members are of much more slender proportions.

The preceding analysis shows that the quadrangular frame will be relatively flexible as compared to a diagonal bracing unless the working stresses for the lateral forces are small and the width of members large. The analysis also shows that for given working stresses the flexibility is inversed proportional to the widths of the members (not to the moments of inertia).

Section IV.—Trussed Beams

286. The King Post Truss.—A combination form of beam and truss often employed is that shown in Fig. 60. The member $A\,B$ is a relatively large beam, supported by the trussing at C. Loads may be applied at any point. The beam $A\,C\,B$, therefore, acts as a strut in the truss $A\,D\,B$ as well as a beam carrying the applied loads directly. The stresses may be solved by the general method of redundant members, assuming the stress in $C\,D$ as redundant. This member is cut at C and the deflections of the beam above, and the truss below, are placed equal.

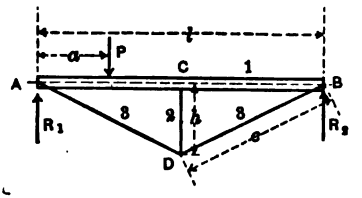

Fig. 60.

Let S_r = stress in $C D$. The deflection of the beam is that due to the load P and the force S_r. By Table 1, p. 10, this is equal to $\frac{P a}{12 E I}\left(\frac{3 l^2}{4} - a^2\right) - \frac{S_r l^3}{48 E I}$. The deflection of the truss is found by calculating the value of $\Sigma \frac{S u l}{E A}$, for a load of S_r at C. The calculations are as follows:

Member.	S	u	$\frac{u l}{A}$	$\frac{S u l}{A}$
1	$-\frac{S_r l}{4 h}$	$-\frac{l}{4 h}$	$-\frac{l^2}{8 h A_1}$	$\frac{S_r l^2}{32 h^2 A_1}$
2	$-S_r$	-1	$-\frac{h}{A_2}$	$\frac{S_r h}{A_2}$
3	$+\frac{S_r c}{2 h}$	$+\frac{c}{2 h}$	$+\frac{c^2}{2 h A_3}$	$\frac{S_r c^2}{4 h^2 A_3}$

Adding, and taking twice the given values for members 1 and 3, we have for the truss =

$$\Delta = S_r\left[\frac{l^3}{16 h^2 E_1 A_1} + \frac{h}{E_2 A_2} + \frac{c^3}{2 h^2 E_3 A_3}\right]$$

whence, writing the deflections equal and solving for S_r, we have

$$S_r = \frac{\frac{P a}{12 E_1 I_1}\left(\frac{3 l^2}{4} - a^2\right)}{\frac{l^3}{16 h^2 E_1 A_1} + \frac{h}{E_2 A_2} + \frac{c^3}{2 h^2 E_3 A_3} + \frac{l^3}{48 E_1 I_1}} \quad . \quad (47)$$

Frequently the beam is of wood and the trussing iron or steel, in which case the values of the various moduli must be used. Generally the terms in the denominator of (47) involving direct stress are small as compared to those involving moment, and may be neglected, giving

$$S_r = \frac{4 P a}{l^3}\left(\frac{3 l^2}{4} - a^2\right) \quad . \quad . \quad . \quad . \quad . \quad (48)$$

which is the centre reaction for a beam continuous over three supports.

For a uniform load w, extending from a distance $a = x_1$ to a distance $a = x_2$, the numerator of (47) is changed by placing $P =$

$w\,d\,x$ and $a = x$, and integrating $P\,a\,(\frac{3}{4}\,l^2 - a^2)$ from x_1 to x_2. For a full uniform load the numerator is the central deflection of a beam uniformly loaded $= \dfrac{5\,w\,l^4}{384\,E\,I}$.

287. The Queen Post Truss Without Diagonals.—Trussed beams are sometimes made of the form shown in Fig. 61, the member $A\,D$

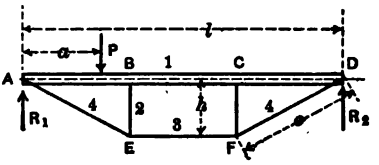

FIG. 61.

being a continuous beam. No diagonals being used in the middle panel, the rigidity of the construction depends upon the strength of the beam, the trussing furnishing equal reactions at B and C.

Let S_r = stress in $B\,E$ and $C\,F$, assumed as equal. This is very nearly true, as the small deflections of E and F do not appreciably change the inclinations of $A\,E$, $E\,F$, and $F\,D$. The horizontal components of $A\,E$ and $F\,D$ being equal (equal to the stress in $E\,F$), their vertical components are equal and hence the stresses in $B\,E$ and $C\,F$.

The problem is solved by determining the *sum* of the deflections of points B and C as regards the beam, and placing this equal to the same sum as calculated from the truss. Since the truss alone is unstable, the deflection of one of the points depends upon the other, but the sum of the two is a definite quantity.

For a load P, placed between A and B, the deflections of B and C are given by the table p. 10. They are

$$\Delta_b = \frac{P\,a}{9\,E\,I}\left(\frac{5\,l^2}{9} - a^2\right)$$

$$\Delta_c = \frac{P\,a}{18\,E\,I}\left(\frac{8\,l^2}{9} - a^2\right)$$

Then

$$\Delta_b + \Delta_c = \frac{P\,a}{18\,E\,I}\,(2\,l^2 - 3\,a^2).$$

For two upward forces S_r, applied at B and C, the deflection of each point is equal to

$$\Delta'_b = \frac{5\, S_r l^3}{162\, E I}$$

and the sum of the deflections for the two points is $\frac{5\, S_r l^3}{81\, E I}$. The downward deflection of the truss at B and C, due to two forces S_r, is calculated as before. It is

$$\Delta'' = S_r \left[\frac{l^3}{9\, h^2 E_1 A_1} + \frac{2\, h}{E_2 A_2} + \frac{l^3}{27\, h^2 E_3 A_3} + \frac{2\, c^3}{h^2 E_4 A_4} \right].$$

Placing $\Delta_b + \Delta_c - 2\, \Delta'_b = \Delta''$, and solving for S_r, we have,

$$S_r = \frac{\frac{P\, a}{18\, E_1 I_1} (2\, l^2 - 3\, a^2)}{\frac{l^3}{9\, h^2 E_1 A_1} + \frac{2\, h}{E_2 A_2} + \frac{l^3}{27\, h^2 E_3 A_3} + \frac{2\, c^3}{h^2 E_4 A_4} + \frac{5\, l^3}{81\, E_1 I_1}} \quad . \quad (49)$$

For a load between B and C

$$S_r = \frac{\frac{P\, l}{162\, E_1 I_1} [27\, (a\, l - a^2) - l^2]}{D_{49}} \quad . \quad . \quad . \quad (50)$$

in which D_{49} is the denominator in eq. (49). For a full uniform load of w per unit length, the value of S_r is

$$S_r = \frac{\frac{11\, w\, l^4}{486\, E I}}{D_{49}} \quad . \quad . \quad . \quad . \quad . \quad . \quad . \quad (51)$$

If the direct stresses are neglected in (49), the value of the denominator becomes equal to $\frac{5\, l^3}{81\, E I}$. For a load at B or C, $a = l/3$, and we have $S_r = P/2$, that is, the truss carries one-half the load and the beam one-half. The upward pressure at C is also $P/2$, thus giving a point of inflection in the beam at the centre.

For trussed beams of three or more panels, with full diagonal bracing, the case becomes similar to the calculation of secondary stresses in trusses with rigid joints. This case is fully treated in the following chapter.

288. Truss of Several Panels with Diagonals Omitted in One Panel.—It is sometimes desired to estimate the supporting power of a truss from which one of the web members has been removed, the chords being continuous and the joints riveted. The strength of such a truss is dependent upon the bending resistance of the chord members $C\,D$ and $E\,F$, but the exact stresses therein, due to a given loading, can be calculated only by considering all the joints of the structure. Generally a sufficiently exact result can be obtained by assuming the points of inflection of $C\,D$ and $E\,F$ to be at their centres,

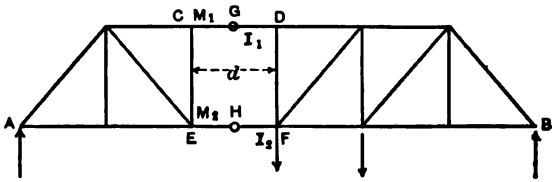

FIG. 62.

G and H. Let V = shear in panel $E\,F$, caused by any load, Fig. 62. The sum of the moments at C and E, in $C\,D$ and $E\,F$, is then $V \times \frac{d}{2}$, and the relative moments carried by the two members will be in proportion to their moments of inertia (their deflections being equal). Hence we have $M_1 + M_2 = V\frac{d}{2}$, and $\frac{M_1}{M_2} = \frac{I_1}{I_2}$, whence

$$M_1 = \frac{V\,d\,I_1}{2\,(I_1 + I_2)} \quad \text{and} \quad M_2 = \frac{V\,d\,I_2}{2\,(I_1 + I_2)}. \quad . \quad . \quad (52)$$

For a more exact solution recourse must be had to the methods used in calculating secondary stresses (Chapter VII).

SECTION V.—BEAMS ON MULTIPLE ELASTIC SUPPORTS

289. The General Problem.—The problem of determining the distribution of loads upon elastic supports, transferred thereto by means of an intermediate beam, is one which frequently arises in practice, particularly in connection with bridge floors of various types. The maximum load supported by a single cross-tie, or one element of a steel floor system, consisting of closely spaced transverse members,

such as *I*-beams, or trough-shaped sections, are problems of this kind. Usually a solution is reached by making an approximate estimate which will be certain to be on the safe side. It is not difficult, however, to arrive at a reasonably exact solution by methods used in solving other statically indeterminate combinations. In the following articles a general solution will be given, and a diagram from which numerical results may readily be obtained for a variety of conditions.

290. General Method of Solution.—Fig. 63 represents an arrangement such as here considered. *A B* is a longitudinal beam supporting

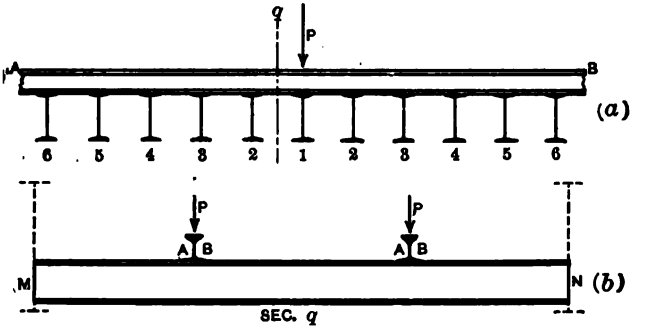

FIG. 63.

a concentrated load, *P*. The beam, *A B*, rests upon numerous transverse beams, 1, 2, 3, 4, etc., which in turn are supported at their ends by relatively deep and rigid girders or other rigid supports. Fig. (*b*) shows one of the transverse beams *M N*, supporting two longitudinal beams, *A B*, symmetrically placed, as in the case of the usual single-track railway bridge-floor. The beams *M N* may be ties resting upon stringers, or units of a steel floor system riveted into longitudinal girders; and the beam, *A B*, may be merely the rail, or a rail together with channel, *I*-beam, or other supplementary support. In any case the beam, *A B*, as here considered, includes all of the elements acting together to support the load *P*. In determining the moment of inertia of this combination the moment of inertia of each independent part is to be taken about its own gravity axis and the results added. If one element is of wood and another of steel, then, as will later appear, the product *E I* of each element is to be taken and the results added.

In the solution of this problem it is assumed that the supports of the transverse beam $M\ N$ are so rigid, compared to the beam $A\ B$, that they may be assumed as absolutely so. The various transverse beams, 1, 2, 3, etc., will, therefore, deflect in proportion to the load brought upon them, or in proportion to the reaction which they supply to the beam $A\ B$. Generally the beam $A\ B$ is continuous over a large number of transverse supports, and, in turn, it supports several loads P, of various weights and spacing.

In arriving at a solution it will be sufficiently exact to consider not more than nine supports, symmetrically spaced with respect to the load P, and to assume that the beam $A\ B$ ends at the last support at either end. The principal problem is to determine the load carried by beam No. 1, immediately beneath the load P, but at the same time the loads carried by the other beams should be found. The error involved by neglecting the supports beyond the nine here considered is very small, and in most cases the results are accurate enough if only seven supports are considered.

If additional loads are applied to the beam $A\ B$, within the length considered, their effect upon the load carried by No. 1, can be found from the results obtained for the load P. Thus if a load P' is placed over beam No. 3, the proportion of P' transferred to No. 1 may be taken as the same as the proportion of P carried by No. 3, etc. Loads beyond the last support considered do not appreciably affect the load on No. 1.

291. Deflection of the Transverse Beam.—Fig. 64 represents a transverse beam of length b, loaded with two equal loads, Q, symmetri-

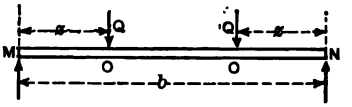

FIG. 64.

cally spaced a distance z from the ends. The deflection of points O, where the loads are applied, is given by the formula of Table 1, p. 12. In terms of the load Q, it is

$$\Delta = \frac{Q\,z^2}{6\,E\,I}\,(3\,l - 4\,z). \quad . \quad . \quad . \quad . \quad . \quad (1)$$

It will also be desirable to express this deflection in terms of the maximum fibre stress due to the load Q. The bending moment $= Q\,z$ and the fibre stress $= f = \frac{M\,h}{2\,I} = \frac{Q\,z\,h}{2\,I}$; whence $Q\,z = \frac{2\,I\,f}{h}$. Substituting in (1), we then have also

$$\Delta = \frac{f\,z}{3\,E\,h}\,(3\,l - 4\,z) \quad . \quad . \quad . \quad . \quad . \quad . \quad (2)$$

in which h is the depth of the beam, assumed as symmetrical about its neutral axis.

In the subsequent analysis it is necessary to have a measure of the flexibility of the transverse beams. A convenient measure or coefficient of this flexibility is the amount of deflection at the points O, due to a load of one pound placed at each point. If k represents this coefficient of flexibility, then

$$k = \frac{\Delta}{Q} = \frac{z^2}{6\,E\,I}\,(3\,l - 4\,z), \quad . \quad . \quad . \quad . \quad (3)$$

also

$$k = \frac{f\,z}{3\,E\,h\,Q}\,(3\,l - 4\,z). \quad . \quad . \quad . \quad . \quad . \quad (4)$$

Generally the problem relates to a specific design already determined by approximate methods. In this case k is determined from (3), as the value of I is already known. In making a new design,

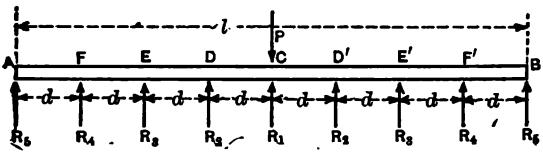

FIG. 65.

however, it is considerably more expeditious to fix only upon the depth h of the floor or beam. Then, using an estimated value of Q, the value of k is at once found from (4), without fully working out the cross-section of the floor element. Having k, the true value of Q is found as described later, and then if desired a corrected value of k. A considerable variation in k will affect the value of Q but little.

292. The Longitudinal Beam.—Fig. 65 represents the longitudinal beam, $A\,B$, and the several reactions, $R_1 \ldots\ldots R_5$, spaced a distance,

d, apart. The total moment of inertia of the beam $A\ B$ is I, and its modulus of elasticity is E. These enter into the calculation only as the product $E\ I$, and if two kinds of material are used, the total value of $E\ I$ is to be obtained by adding these products for the several elements.

The forces being vertical, only two reactions can be determined by statics. There are, therefore, seven redundant reactions. These may be taken as reactions $R_1 \ldots\ldots R_4$, the end reactions, R_5, being considered as the two "necessary" reactions. By reason of symmetry of arrangement the reactions on one side are equal to those on the other side, symmetrically located; hence there are practically only four unknowns, $R_1 \ldots\ldots R_4$, which requires for solution four condition equations. These condition equations may be obtained by the method of least work, expressing the total work performed in the deflection of the beam and its supports, then differentiating with respect to each support and placing such derivative equal to zero; or they may be obtained by the method of redundant members, placing the deflection of the beam at each support equal to the settlement of that support. The latter method is the simpler, and in its application the deflection formula given in the Table on p. 10 will be made use of directly, instead of using the fundamental expressions of Art. 243.

The four condition equations will then be obtained by placing the deflection of the beam at points C, D, E, and F, equal to the deflection of the respective support, which in general is equal to $R\ k$, where R is the reaction at any point. If Δ_c, Δ_d, etc., are the deflections at the several points, then the equations are, in general terms:

$$\left.\begin{aligned} \Delta_c &= R_1\, k \\ \Delta_d &= R_2\, k \\ \Delta_e &= R_3\, k \\ \Delta_f &= R_4\, k \end{aligned}\right\} \quad \ldots\ldots\ldots \quad (5)$$

In calculating the deflections Δ, the effect of the load P, and of the several reactions, $R_1 \ldots\ldots R_4$, may be expressed separately, and the several results added.

293. *Deflections Due to Load P.*—In calculating the deflection due

to the load P, it is assumed that the forces, $R_1 \ldots\ldots R_4$, are removed. The deflection of any point will then be that due to: (1) the bending of the beam under load P, with reactions at A and B, and (2) the settlement of the supports at A and B, which will be $\frac{P}{2} k$. The deflection of any point of a beam, supporting a single load P, at the centre, is given by the general formula (Table 1, p. 10) $y = \frac{P x}{48 E I} (3 l^2 - 4 x^2)$, in which x is the distance of the point from the near end of the beam. Applying this formula to the several points, C, D, E, and F, the value of x will be equal to $4 d$, $3 d$, $2 d$, and d. We have also, $l = 8 d$. Adding in each case the quantity $\frac{P}{2} k$, we obtain the following values for the deflections due to P:

$$\left.\begin{aligned} \delta_c &= P\left(\frac{32 d^3}{3 E I} + \frac{k}{2}\right) \\ \delta_d &= P\left(\frac{39 d^3}{4 E I} + \frac{k}{2}\right) \\ \delta_e &= P\left(\frac{22 d^3}{3 E I} + \frac{k}{2}\right) \\ \delta_f &= P\left(\frac{47 d^3}{12 E I} + \frac{k}{2}\right) \end{aligned}\right\} \quad \ldots\ldots\ldots \quad (6)$$

294. *Deflections Due to* R_1.—These deflections will be given by the same equations as for P, the deflections being upward.

295. *Deflections Due to* R_2.—The deflections due to the two symmetrical loads, R_2, are obtained by the general formulas from Table 1. They are:

$$\left.\begin{aligned} &\text{for } x < z, \quad y = \frac{P x}{6 E I} (3 l z - 3 z^2 - x^2) \\ &\text{for } x > z, \quad y = \frac{P z}{6 E I} (3 l x - 3 x^2 - z^2) \end{aligned}\right\} \quad \ldots \quad (7)$$

In this case, since there are two equal forces, R_2, the end reactions due to these loads are each equal to R_2, and the movement of end supports due to their elasticity, will be $R_2 k$. In applying eq. (7), $l = 8 d$, and $z = 3 d$. For point C, $x = 4 d$, and the second equation (7) is used.

The several deflections are:

$$\left.\begin{aligned} \delta_c &= R_2\left(\frac{39\,d^3}{2\,EI} + k\right) \\ \delta_d &= R_2\left(\frac{18\,d^3}{EI} + k\right) \\ \delta_e &= R_2\left(\frac{41\,d^3}{3\,EI} + k\right) \\ \delta_f &= R_2\left(\frac{22\,d^3}{3\,EI} + k\right) \end{aligned}\right\} \quad \ldots\ldots \quad (8)$$

By the principle of reciprocal deflections explained in Art. 220, Part I, it is observed that the deflection at C, due to a single force applied at D, is equal to the deflection at D due to a like force applied at C. Hence the value of δ_c of eq. (8) is double the value of δ_d of eq. (6).

296. *Deflections Due to* R_3.—In this case $z = 2\,d$ in eq. (7). The only values requiring calculation are δ_e and δ_f, as the value of δ_c is twice δ_e of eq. (6), and $\delta_d = \delta_e$ of eq. (8). The results are:

$$\left.\begin{aligned} \delta_c &= R_3\left(\frac{44\,d^3}{3\,EI} + k\right) \\ \delta_d &= R_3\left(\frac{41\,d^3}{3\,EI} + k\right) \\ \delta_e &= R_3\left(\frac{32\,d^3}{3\,EI} + k\right) \\ \delta_f &= R_3\left(\frac{35\,d^3}{6\,EI} + k\right) \end{aligned}\right\} \quad \ldots\ldots \quad (9)$$

297. *Deflections Due to* R_4.—The values of δ_c, δ_d, and δ_e are obtained from the values of δ_f of eqs. (6), (8), and (9). The value of δ_f is calculated from eq. (7). The results are:

$$\left.\begin{aligned} \delta_c &= R_4\left(\frac{47\,d^3}{6\,EI} + k\right). \\ \delta_d &= R_4\left(\frac{22\,d^3}{3\,EI} + k\right) \\ \delta_e &= R_4\left(\frac{35\,d^3}{6\,EI} + k\right) \\ \delta_f &= R_4\left(\frac{10\,d^3}{3\,EI} + k\right) \end{aligned}\right\} \quad \ldots\ldots \quad (10)$$

298. *Resulting Equations.*—Placing the total deflection at C, for all loads and forces, equal to $R_1 k$, we have the following equation:

$$P\left(\frac{32\,d^3}{3EI}+\frac{k}{2}\right)-R_1\left(\frac{32\,d^3}{3EI}+\frac{k}{2}\right)-R_2\left(\frac{39\,d^3}{2EI}+k\right)-R_3\left(\frac{44\,d^3}{3EI}+k\right)-R_4\left(\frac{47\,d^3}{6EI}+k\right)=R_1 k.$$

Similar equations are derived by placing the total deflection at D equal to $R_2 k$, that at E equal to $R_3 k$, and that at F equal to $R_4 k$.

Simplifying these equations by dividing by $\frac{d^3}{EI}$ and placing $\frac{kEI}{d^3} = a$, we derive the four simple equations:

$$\left.\begin{aligned}
R_1(\,64+9a)+R_2(117+\,6a)+R_3(\,88+\,6a)+R_4(47+\,6a)&=P(\,64+3a)\\
R_1(117+6a)+R_2(216+24a)+R_3(164+12a)+R_4(88+12a)&=P(117+6a)\\
R_1(\,44+3a)+R_2(\,82+\,6a)+R_3(\,64+12a)+R_4(35+\,6a)&=P(\,44+3a)\\
R_1(\,47+6a)+R_2(\,88+12a)+R_3(\,70+12a)+R_4(40+24a)&=P(\,47+6a)
\end{aligned}\right\}\quad . \quad (11)$$

The algebraic solution need not be carried further. In any problem the numerical value of $a = \frac{kEI}{d^3}$ should be calculated, then substituted in eq. (11), and the values of R_1, R_2, R_3, and R_4 determined by elimination.

299. *Equations for Seven and Five Supports.*—As it may be desired to analyze a case where a less number of supports are involved, there are given here the necessary equations for the case of seven supports and five supports, calculated in the same manner as above described. For fairly rigid supports the equations for seven or even five supports will give sufficiently accurate results for R_1.

For seven supports:

$$\left.\begin{aligned}
R_1(27+9a)+R_2(46+\,6a)+R_3(26+\,6a)&=P(27+3a)\\
R_1(23+3a)+R_2(40+12a)+R_3(23+\,6a)&=P(23+3a)\\
R_1(13+3a)+R_2(23+\,6a)+R_3(14+12a)&=P(13+3a)
\end{aligned}\right\}\quad . \quad (12)$$

For five supports:

$$\left.\begin{aligned}
R_1(\,8+9a)+R_2(11+\,6a)&=P(\,8+3a)\\
R_1(11+6a)+R_2(16+24a)&=P(11+6a)
\end{aligned}\right\}\quad . \quad (13)$$

300. Diagram for Values of Reactions.—In the usual problem of bridge-floor design the value of a will rarely be less than 1 nor more

than 10. The practical application of this method can therefore be greatly facilitated by constructing a diagram of the values of the ratio of maximum reaction R_1, to the concentrated load P. Such a diagram is given in Fig. 66, calculated from eq. (11), Art. 298. In addition, the values of R_2, R_3, and R_4 are also given for use where two concentrations are spaced closer together than 4 d.

It can be shown theoretically that where the supports are very closely spaced and the spacing of loads relatively great, the value of R_1 is closely given by the formula

$$R_1 = \frac{P}{2.82\sqrt[4]{a}}. \quad . \quad . \quad . \quad . \quad . \quad . \quad . \quad (14)$$

This formula is represented by the dotted line in Fig. 66. Eq. (14) shows that the value of R_1 varies with $\sqrt[4]{a}$ or $\sqrt[4]{\frac{k\,E\,I}{d^3}}$. A roughly approximate estimate of k is therefore sufficient to determine R_1 with a good degree of accuracy.

EXAMPLES.—(1) What will be the maximum load on one tie of a bridge floor, the ties being of oak, 8″x8″ in section, spaced 12 in. apart and supported by stringers spaced 7 ft. apart. The rail is a 90-lb. rail with a moment of inertia of 35.2.

The modulus of elasticity of the tie may be taken at 2,000,000. Its moment of inertia is 341. Then from eq. (3) the value of the coefficient k is equal to $\frac{12^2}{6 \times 2{,}000{,}000 \times 341}(21 - 4) \times 12 = .0000072$. The value of a of eq. (11) is then

$$a = \frac{k\,E\,I}{d^3} = \frac{.0000072 \times 30{,}000{,}000 \times 35.2}{12^3} = 4.40.$$

From the diagram, Fig. 66, we find, for $a = 4.4$, $R_1/P = 0.26$, that is, the maximum load on one tie is 26 per cent of the wheel concentration. The load on the next tie is about 22 per cent, on the third tie is about 14 per cent, and on the fourth it amounts to 5 per cent. A second wheel spaced three ties (three feet) from the first will add about 5 per cent of its weight to the load under the wheel in question.

(2) Suppose a single-track steel floor system is to consist of elements spaced 16 ins. apart and of a depth of 18 in. Suppose, further, that the working stress to be employed is 15,000 lbs. per sq. in., and that the wheel concentration is 30,000 lbs., plus 100 per cent for impact. Let it be required to determine the maximum load on one of the floor elements. The width of the floor between supports is 12 ft., and the rails are 100 lb. rails having a

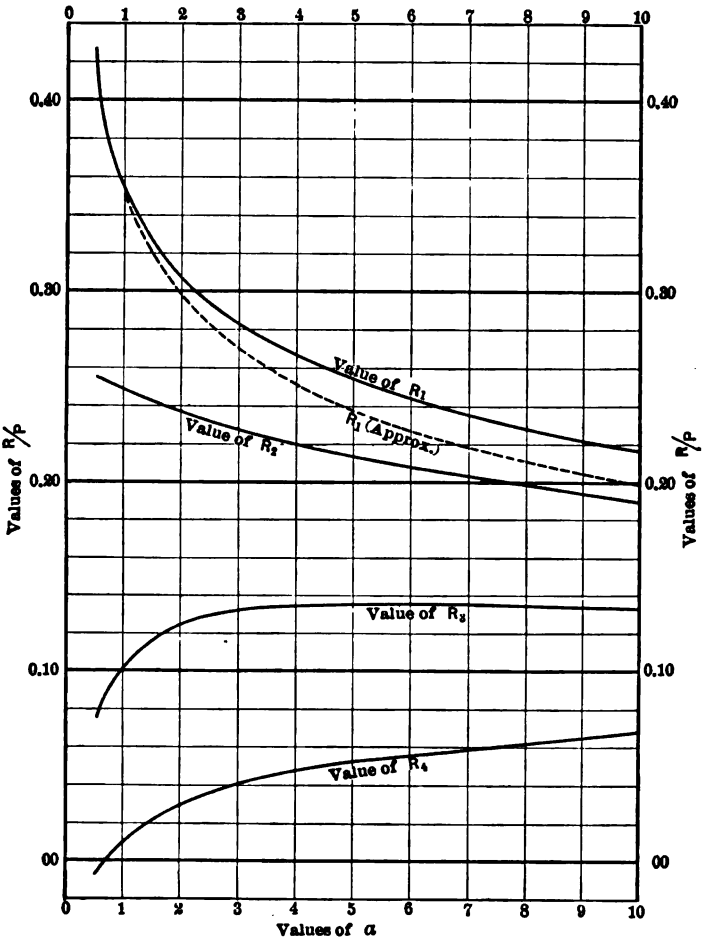

$$a = \frac{k\,E\,I}{d^3},$$

k = deflection in inches of the transverse beam for a load of one pound,

d = spacing in inches of transverse beams,

E and I refer to longitudinal beam $A\ B$.

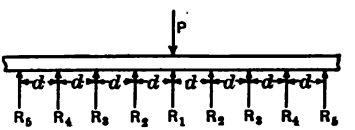

FIG. 66.—DIAGRAM OF REACTIONS FOR A BEAM ON MULTIPLE SUPPORTS.

moment of inertia of 44.4. They are supported in 10-in. channels having a moment of inertia of 4.0. The total value of I for the combination is therefore 48.4.

The value of k will be first estimated from eq. (4). Assuming approximately that $Q = 40$ per cent of the wheel load, $= 24{,}000$ lbs., we have, for $l = 12$ ft., $z = 3.5$ ft., $h = 18$ in.,

$$k = \frac{15{,}000 \times 3.5 \times 12 \times (36 - 14) \times 12}{3 \times 18 \times 24{,}000 \times E} = \frac{128}{E}.$$

$$a = \frac{k E I}{d^3} = \frac{128 \times 48.4}{16^3} = 1.5.$$

With $a = 1.5$ we find from Fig. 66, $R_1 = 32$ per cent of P or 19,200 lbs.

We can now correct the value of k in eq. (4), finding, for $Q = 19{,}200$, $k = \frac{160}{E}$. Then $a = 1.9$ and the diagram gives $R_1 = 31$ per cent of P. If the transverse beam is now designed for a load of $.31 \times 60{,}000 = 18{,}600$ lbs., at a working stress of 15,000 lbs. per sq. in., it will meet the conditions of the problem.

CHAPTER VII

SECONDARY STRESSES

301. Primary and Secondary Stresses.—It has been assumed heretofore in the analysis of stresses that all members of a truss are free to turn at the joints. It has also been assumed that all members are straight, that the joints lie in the gravity axes of the members, and that all external loads, including the weight of the members, are applied at the joints only. The stresses so calculated are the *axial* or *direct stresses.* They may also be called the *primary stresses* in the truss.

These assumed conditions are not realized in practice. The joints offer more or less resistance to the turning of the members; the members themselves are not straight; the joints are often eccentric; and, finally, the weights of the individual members must be carried to the joints by the members themselves acting as beams. By reason of these modifying causes the members of the truss are in general subjected not only to axial or direct stresses, but also to bending moments, involving bending and shearing stresses. In a complete analysis of stresses it is convenient to calculate, first, the primary or axial stresses under the usual assumptions, and afterward to calculate separately the effects of the modifying conditions here mentioned, the resulting stresses being called *secondary stresses.* It will be found that the most important of the secondary stresses are the bending stresses; the shearing stresses, may, however, be important in some cases. There are also small secondary axial stresses, which act to modify slightly the primary stresses already found. These are also very small and need not usually be considered.

302. Secondary Stresses Due to Rigidity of Joints. Nature of the Problem.—If the members of a truss were free to turn at the joints, the longitudinal deformations which are produced in the various members by their axial stress would, in general, cause a slight change in angle between all the members at all the joints. In the truss *a k*

Fig. 1, for example, suppose the nature of the stresses in the various members to be as indicated by the signs. In the triangle $a\,b\,c$ the member $a\,c$ will be shortened and the members $c\,b$ and $a\,b$ will be lengthened. This will cause a decrease in the angle at b and an increase or decrease in the angles at a and c, depending upon the relative changes in $a\,b$ and $c\,b$. If the changes in the lengths of these members are known, it is possible to calculate what the changes in the several angles will

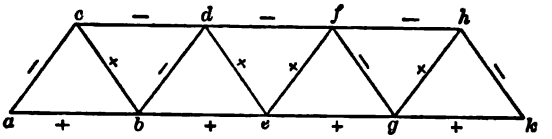

Fig. 1.

be. So, also, for the other angles, it is evident that if the changes in lengths of all the members are known, the changes in all the angles can be determined.

Now suppose the members are rigidly connected at all the joints, by riveting or otherwise, so that the angles between the various members cannot change. The lengths of the members will still be changed

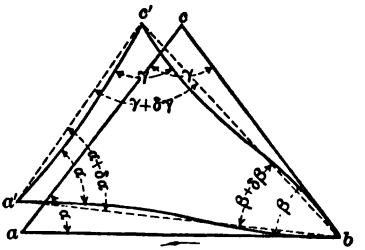

Fig. 2.

as before, from the axial stresses, and the vertices of the triangles will move as before. This movement will now force the members of a triangle to bend, as represented diagrammatically in Fig. 2, thus producing bending moments in the members which are a maximum near the joints. The secondary stresses arising from these moments are, in many cases, of large amount, and require careful consideration. It is generally possible and sufficient to so design a structure as to

keep these stresses within low limits, and then to neglect them in the calculations, but in many special cases and in large and important structures they will require calculation.

In Fig. 2, let a, b, and c represent the original positions of the three joints, and a', b, and c' the positions after the members are stressed. Let α, β, and γ represent the original angles at a, b, and c, and $\delta\,\alpha$, $\delta\,\beta$, and $\delta\,\gamma$ the changes in these angles if the members were free to turn at the joints. The angles between the dotted straight lines joining a', b, and c', will then be equal to $\alpha + \delta\,\alpha$, $\beta + \delta\,\beta$, and $\gamma + \delta\,\gamma$, respectively. In proceeding with a solution of the problem, the changes of angle $\delta\,\alpha$, $\delta\,\beta$, and $\delta\,\gamma$ are first found from the known changes of lengths of the sides of the triangle due to axial stresses. From these changes of angle the bending moments in the members are then calculated. The process requires the simultaneous consideration of all the members and angles of the truss and is, therefore, somewhat tedious, although simple in application if careful attention is paid to signs and the work is well systematized.

303. Calculation of the Changes of Angle in Any Triangle in Terms of the Changes in the Lengths of the Members.—Let $a\,b\,c$, Fig. 3, be

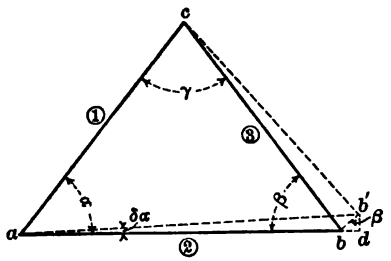

FIG. 3.

the original form of a triangle. Number the members 1, 2, 3, as shown and let

$$s_1, s_2, s_3 = \text{stress intensity in each member;}$$
$$l_1, l_2, l_3 = \text{length of each member;}$$
$$E = \text{modulus of elasticity.}$$

Then the change in length of any member will be in general $\frac{s\,l}{E}$.

Consider the angle α and the change caused in this angle by changes of length in the various members, the joints being frictionless and the members remaining straight. Each member may be considered separately and the results added (the deformations being small). It will be assumed that each member increases in length, an increase being considered as a positive deformation.

Suppose, first, that $a\,b$ is elongated by an amount $\frac{s_2 l_2}{E}$, shown as $b\,d$ in the figure. Assuming a and c to stand fast, the point b will move to b', on a line $b\,b'$ drawn perpendicular to $b\,c$ and intersecting a line $d\,b'$ perpendicular to $a\,b$. Then $\delta\,\alpha = -\frac{b'\,d}{l_2}$. But $b'\,d = b\,d\,\cot\,\beta = \frac{s_2 l_2}{E}\cot\,\beta$. Hence $\delta\,\alpha = -\frac{s_2}{E}\cot\,\beta$. In the same manner it is found that for a change of length in member $a\,c$, $\delta\,\alpha = -\frac{s_1}{E}\cot\,\gamma$. For a change in member $b\,c$, let point b (Fig. 4) stand fast

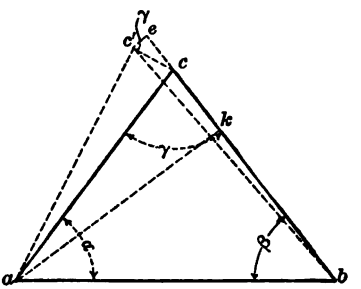

FIG. 4.

and let $c\,e\,\left(=\frac{s_3 l_3}{E}\right)$ represent the elongation of $b\,c$. The position of c will be at c', the intersection of the perpendiculars $c\,c'$ and $e\,c'$. Then $\delta\,\alpha = \frac{c\,c'}{a\,c} = \frac{c\,e}{a\,c\,\sin\,\gamma} = \frac{s_3 l_3}{E\,a\,c\,\sin\,\gamma}$. But $a\,c\,\sin\,\gamma = a\,k = \frac{b\,c}{\cot\,\beta + \cot\,\gamma}$, hence we derive by substitution, $\delta\,\alpha = \frac{s_3}{E}(\cot\,\beta + \cot\,\gamma)$.

The total change in α due to changes of length in all three members, may then be expressed by the convenient formula,

$$\delta\alpha = \frac{s_3 - s_2}{E}\cot\beta + \frac{s_3 - s_1}{E}\cot\gamma. \quad . \quad . \quad . \quad (1)$$

Likewise, we have for the other angles

$$\delta\beta = \frac{s_1 - s_3}{E}\cot\gamma + \frac{s_1 - s_2}{E}\cot\alpha. \quad . \quad . \quad . \quad (2)$$

and

$$\delta\gamma = \frac{s_2 - s_1}{E}\cot\alpha + \frac{s_2 - s_3}{E}\cot\beta. \quad . \quad . \quad . \quad (3)$$

Note that in each case the numerator is the value of s for the side opposite, minus that for the side adjacent, times the cotangent of the included angle.

In calculations of the changes of angles in a triangle, a convenient check is the relation

$$\delta\alpha + \delta\gamma + \delta\beta = 0. \quad . \quad . \quad . \quad . \quad . \quad . \quad . \quad (4)$$

304. The Deflection Angles of a Beam Subjected to Given Moments Applied at the Two Ends.—Consider the beam $A\,B$, Fig. 5, subjected

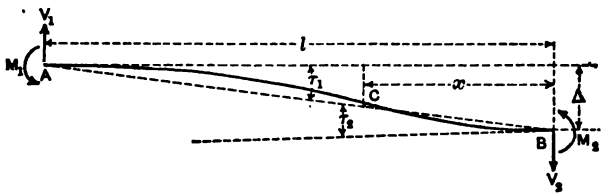

FIG. 5.

to the moments M_1 and M_2, and shears V_1 and V_2, but sustaining no intermediate loads. Assume a counter-clockwise direction of moment to be positive.

From $\Sigma M = 0$ at A and B, we have,

$$V_1 = V_2 = \frac{M_1 + M_2}{l}. \quad . \quad . \quad . \quad . \quad . \quad . \quad (5)$$

At any point C, distant x from B, the bending moment is

$$M_x = M_2 - V_2 x = M_2 - (M_1 + M_2)\frac{x}{l}. \quad . \quad . \quad . \quad (6)$$

The deflection Δ, at B, with respect to the tangent at A, considered as

positive downward, will be equal to $-\int_B^A \frac{M\,x\,dx}{EI}$ (see Art. 3), or

$$\Delta = -\frac{1}{EI}\int_0^l \left[M_2 x - (M_1 + M_2)\frac{x^2}{l}\right] dx$$

$$= \frac{l^2}{6\,EI}(2\,M_1 - M_2). \quad . \quad . \quad . \quad . \quad . \quad . \quad . \quad . \quad . \quad (7)$$

The value of the deflection angle τ_1 is Δ/l, or

$$\tau_1 = \frac{l}{6\,EI}(2\,M_1 - M_2). \quad . \quad . \quad . \quad . \quad . \quad . \quad (8)$$

Likewise

$$\tau_2 = \frac{l}{6\,EI}(2\,M_2 - M_1). \quad . \quad . \quad . \quad . \quad . \quad . \quad (9)$$

Eqs. (8) and (9) may be solved for M_1 and M_2 in terms of τ_1 and τ_2, giving

$$M_1 = \frac{2\,EI}{l}(2\,\tau_1 + \tau_2) \quad . \quad . \quad . \quad . \quad . \quad . \quad (10)$$

and

$$M_2 = \frac{2\,EI}{l}(2\,\tau_2 + \tau_1). \quad . \quad . \quad . \quad . \quad . \quad . \quad (11)$$

In a truss, distorted as indicated in Fig. 2, the members are subjected to bending moments and shears like the beam in Fig. 5. In addition to the forces here considered, there exist also the primary or direct stresses, which have been omitted in Fig. 5. So long as the distortion is small and the joints concentric, these direct stresses have little effect upon the bending moments, the lever arm being small, but where the distortion is large they exert a considerable influence thereon, especially in the case of compression members. It is possible to include this effect in the analysis, but such a solution is very laborious and not in general practicable. The methods of such exact treatment are considered in a subsequent article. For the present, the effect of the direct stresses upon the bending moments will be neglected. Where the joints are eccentric, the direct stresses cause large bending moments even though the deflection of the member is small. This case will be fully considered.

305. Notation and Conventional Scheme for Signs.—In calculations, such as here discussed, it is important that a convenient notation and

a scheme for signs be adopted and that it be closely adhered to throughout. It will be assumed that when the distortions of the members of a triangle are as shown in Fig. 6, the bending moments in the members at the ends are all positive. The values of τ are also to be considered as all positive.

The joints being numbered, the various τ's and M's will be

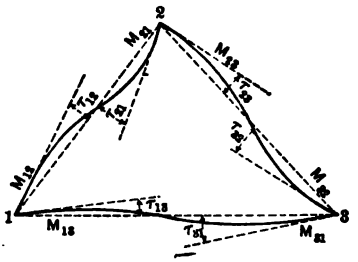

FIG. 6.

designated by subscripts as shown. The lengths and moments of inertia of the members will be denoted in the same way, but $I_{23} = I_{32}$, $l_{23} = l_{32}$, etc. Fig. 7 shows a truss in which all members are represented as having positive moments at their ends and all values of τ are positive.

306. Values of the Deflection Angles τ in Terms of the Changes

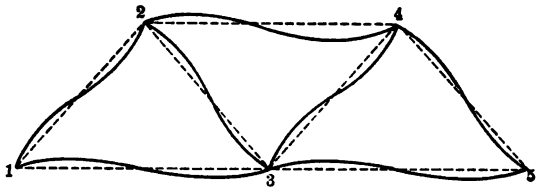

FIG. 7.

of Angle $\delta\alpha$, etc.—Consider any joint n of any structure, Fig. 8, and let the straight lines n-1, n-2, n-3, etc., represent the lines joining the several joints after distortion. The full lines show the bent forms of the several members. The angles τ_{n1}, τ_{n2}, τ_{n3}, and τ_{n4} represent the deflection angles of the several members at joint n. Let α_1, α_2, and α_3 be the original angles between the members 1 n 2, 2 n 3, and

3 *n* 4. After distortion, the angles between the straight lines joining the apexes will be respectively, $\alpha_1 + \delta\alpha_1$, $\alpha_2 + \delta\alpha_2$, and $\alpha_3 + \delta\alpha_3$, as shown. Then if we select one of the deflection angles, as τ_{n1}, as a

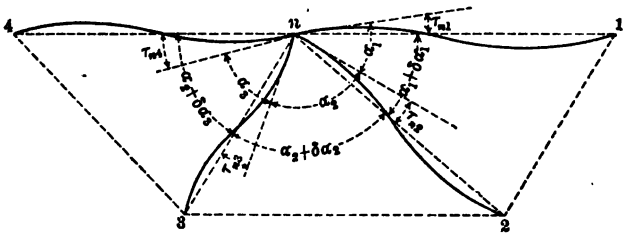

FIG. 8.

reference angle, we may express the other values of τ at joint n in terms of τ_{n1} and the changes of angle $\delta\alpha_1$, etc., as follows:

$$\tau_{n2} = \tau_{n1} + \delta\alpha_1$$
$$\tau_{n3} = \tau_{n1} + \delta\alpha_1 + \delta\alpha_2$$
$$\tau_{n4} = \tau_{n1} + \delta\alpha_1 + \delta\alpha_2 + \delta\alpha_3$$

and so on, for any number of members. Or, in general, we may write for any joint n

$$\tau_{nm} = \tau_{n1} + \Sigma_1^m \delta\alpha, \quad . \quad . \quad . \quad . \quad . \quad . \quad (12)$$

where τ_{nm} represents any value of τ, τ_{n1} is the reference angle selected, and $\Sigma_1^m \delta\alpha$ is the sum of all angular changes up to the member n m in question.

307. Selection of the Reference Deflection Angle.—It will be convenient at each joint of the structure to select a certain angle τ as the reference angle, and to express all the other deflection angles at the joint in terms of this reference angle and the changes of angle $\delta\alpha$, as given in eq. (12). In the following analysis the reference angle will be selected as indicated in Fig. 9, namely, as the deflection angle of the first member encountered in passing around a joint toward the *right*, beginning on the outside of the truss. This deflection angle may be denoted by the use of a single subscript number, the same as that of the joint, as shown in Fig. 9. For an interior joint any convenient angle may be taken, but it must be definitely designated in each case.

308. The Moments at Any Joint in Terms of the Deflection Angles τ.—If the axes of the several members are concentric so that the primary stresses cause no bending moment, then we may write $\Sigma M = 0$

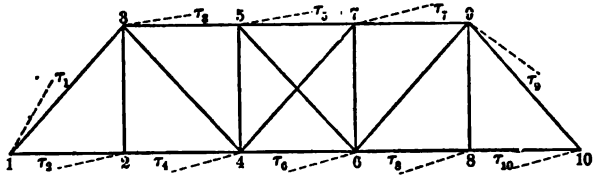

FIG. 9.

for the bending moments at the ends of the members intersecting at any joint. Thus in Fig. 8, we have

$$M_{n1} + M_{n2} + M_{n3} + M_{n4} = 0.$$

Expressing these moments in terms of the several deflection angles τ, as in eq. (10), we have

$$\frac{2EI_{n1}}{l_{n1}}(2\tau_{n1} + \tau_{1n}) + \frac{2EI_{n2}}{l_{n2}}(2\tau_{n2} + \tau_{2n}) + \frac{2EI_{n3}}{l_{n3}}(2\tau_{n3} + \tau_{3n}) + \frac{2EI_{n4}}{l_{n4}}(2\tau_{n4} + \tau_{4n}) = 0. \quad . \quad . \quad . \quad . \quad . \quad (13)$$

A similar equation may be written out for each of the other joints of a structure, thus giving as many equations as there are joints.

Now, as shown in Art. 306, each τ can be expressed in terms of the reference angle τ_n for the joint in question, and the known values of $\delta\alpha_1$, $\delta\alpha_2$, etc. In the several equations will then appear as many different deflection angles as there are joints, thus making the number of equations equal to the number of unknowns. These equations may then be solved for the values of the reference angles τ_n, whence the values of all the τ's are obtained from (12), and finally the bending moments from the general equation (see eq. 10).

$$M_{nm} = \frac{2EI}{l}(2\tau_{nm} + \tau_{mn}). \quad . \quad . \quad . \quad . \quad . \quad (14)$$

In eq. (13) each term contains a quantity I/l. For convenience, let

this be represented by K, using a subscript to indicate the member in question, as K_{n1}, etc. Then eq. (13) becomes (after dividing by $2E$),

$$K_{n1}(2\tau_{n1} + \tau_{1n}) + K_{n2}(2\tau_{n2} + \tau_{2n}) + \text{etc.} = 0, \quad . \quad . \quad . \quad (15)$$

or

$$2(K_{n1}\tau_{n1} + K_{n2}\tau_{n2} + \text{etc.}) + K_{1n}\tau_{1n} + K_{2n}\tau_{2n} + \text{etc.} = 0. \quad (16)$$

Eq. (16) will generally be found the most convenient form to use.

If the axes of the members are not concentric, so that the primary stresses cause a turning moment at the joint, then if M_n represents this external moment, we have $\Sigma M + M_n = 0$, and eq. (16) becomes

$$2(K_{n1}\tau_{n1} + K_{n2}\tau_{n2} + \text{etc.}) + K_{1n}\tau_{1n} + K_{2n}\tau_{2n} + \text{etc.} + \frac{M_n}{2E} = 0. \quad (17)$$

309. *The Fibre Stress in Terms of* τ.—From the general expression $f = \frac{Mc}{I}$ we have, from (14),

$$f_{nm} = \frac{2Ec}{l}(2\tau_{nm} + \tau_{mn}), \quad . \quad . \quad . \quad . \quad (18)$$

in which f = fibre stress at joint n in member $n\,m$, and c = distance of fibre from neutral axis.

310. **Arrangement of the Calculations.**—In calculations such as here considered, it is important to reduce the work to as nearly a mechanical basis as possible, and systematic and convenient methods of tabulation are important. Assuming the primary stresses to be already determined, the process of calculating secondary stresses may be considered in five steps: (1) Calculation of the changes of angle $\delta\alpha$, etc.; (2) tabulation of the values of $\Sigma\,\delta\alpha$, etc., or $\Sigma\,\delta\angle$, as hereafter indicated; (3) formulation of the equations, one for each joint; (4) solution of the equations; and (5) calculation of the several individual values of τ and of the bending moments or fibre stresses.

The most important part of the process is the convenient arrangement of the values of τ so that equation (16) may be readily written out. The solution of these equations is not a long process. The method of arrangement here proposed is most readily explained by means of a numerical example.

Take the truss of Fig. 10 and suppose the loads and dimensions are such that the unit stress s, in members 1-2 and 2-4 is 8,000 lbs

per sq. in., that in 1-4 is 12,000 lbs. per sq. in., and in 2-3 is 15,000 lbs. per sq. in. Furthermore, suppose that the members have the values of I as shown in the figure, taken about axes at right angles to the plane of the truss.

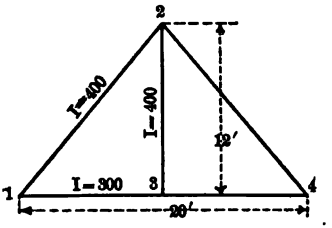

FIG. 10.

311. (*a*) *Calculation of Values of* $\delta\ \angle$.—The general formula for angular change is (eq. 1):

$$\delta\,\alpha = \frac{s_3 - s_2}{E}\cot\beta + \frac{s_3 - s_1}{E}\cot\gamma,$$

where s_3 is the unit stress in member opposite, and s_2 and s_1 are unit stresses in the members adjacent. Tension is plus and compression minus. The angles may be taken in any order, but where the several triangles are similar it is desirable to give the same letter to equal angles. A separate sketch of the truss is made (Fig. 11), on which the

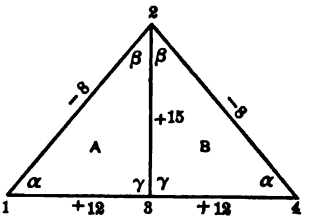

FIG. 11.

angles are lettered and the unit stresses written (shown here in thousands of pounds). The triangles are conveniently lettered A, B, C, etc.

The values of the cotangents are as follows:

$$\cot\alpha = 0.833$$
$$\cot\beta = 1.20$$
$$\cot\gamma = 0$$

Then, by triangles, the values of $\delta\,\alpha$, etc., are calculated as follows, taking $E = 30{,}000{,}000$:

Triangle *A*.

$$\delta\alpha = [(15-20)\times 0 + (15+8)\times 1.2] \div 30{,}000 = +.0000920$$

$$\delta\beta = [(12-15)\times 0 + (12+8)\times .833] \div 30{,}000 = +.0000555$$

$$\delta\gamma = [(-8-12)\times .833 + (-8-15)\times 1.20] \div 30{,}000 = -.0001475$$

Triangle *B*. Same as for triangle *A*.

312. (*b*) *Calculation of the Values of* $\Sigma\,\delta\,\angle$.—The reference angles are indicated in Fig. 12. The several values of $\delta\,\alpha$, etc., are con-

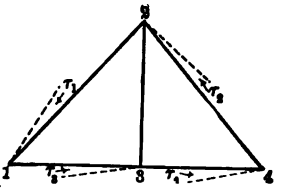

FIG. 12.

veniently put into the form of a table as given on p. 435, arranged in groups by joints.

In Column (2) the internal angles at the several joints are stated in regular order, beginning with the angle first met with in passing around the joint as before described. The first side of the first angle listed at each joint is therefore the member whose deflection angle is the reference angle of that joint. Thus at joint 2, member 2-4 is the one whose deflection angle is the reference angle τ_2. Column (3) contains the values of $\delta\,\alpha$, etc., as obtained in Art. 303. These are called $\delta\,\angle$. Column (4) contains the summation for each joint of the values of Column (3), up to any given angle. Thus at joint 2, the value of $\delta\,\angle$ for $\angle$ 423, is + .0000555, and for 321 is + .0000555. The sum of these is +.0001110. If a third angle existed here its $\delta\,\angle$ would then be added in Column (4) to the value + .0001110 for $\angle$ 321, etc.

In Column (5) are listed the several members meeting at the joint, given in the same order as the angles, the joint number being stated first in each case. In Column (6) are the several values of $K = I/l$

VALUES OF $\delta \angle$, τ, AND M.

Joint.	$\angle$	$\delta \angle$	$\Sigma \delta \angle$	Member.	$K = \frac{I}{l}$	$K \times \Sigma \delta \angle$	τ	$2\tau_{nm} + \tau_{mn}$	Moments.
(1)	(2)	(3)	(4)	(5)	(6)	(7)	(8)	(9)	(10)
				12	2.14	0	−.0001021	−.0001487	−19,090
1	213	+.0000920	+.0000920	13	2.50	+.000230	−.0000101	+.0001273	+19,100
					4.64	+.000230			
				24	2.14	0	−.0000555	+.0000930	+11,940
2	423	+.0000555	+.0000555	23	2.78	+.000155	0	0	
	321	+.0000555	+.0001110	21	2.14	+.000238	+.0000555	−.0000930	−11,940
					7.06	+.000393			
				31	2.50	0	+.0001475	+.0002748	+41,220
3	132	−.0001475	−.0001475	32	2.78	−.000412	0	0	0
	234	−.0001475	−.0002950	34	2.50	−.000737	−.0001475	−.0002748	−41,220
					7.78	−.001149			
				43	2.50	0	+.0000100	−.0001275	−19,130
4	342	+.0000920	+.0000920	42	2.14	+.000197	+.0001020	+.0001485	+19,070
					4.64	+.000197			

for each member, and in Column (7) are the products of Columns (4) and (6).

Columns (6) and (7) are important, as they contain, in convenient form, the values of $K\tau$ for all members, in the following manner: For member 1–2 the value of τ is τ_1, and $K_{12}\tau_{12} = 2.14\,\tau_1$, the coefficient of which quantity is given in Column (6), opposite member 1–2. For member 1–3 the value of τ is τ_{13}, which is equal, by eq. (12), to $\tau_1 + \delta\,(213), = \tau_1 + .000092$. Then $K_{13}\tau_{13} = 2.50\,[\tau_1 + .000092] = 2.50\,\tau_1 + .000230$, as given in Columns (6) and (7) opposite member 1–3, the angle τ_1 being added to the coefficient of Column (6). Again, at joint 2, τ_2 is the reference angle and is the value of τ for member 2–4; and $K_{24}\tau_{24} = 2.14\,\tau_2$, as in Column (6). Then $\tau_{23} = \tau_2 + \delta\,(423) = \tau_2 + .0000555$, and $K_{23}\,\tau_{23} = 2.78\,\tau_2 + .000155$; also $\tau_{21} = \tau_2 + \delta\,(423) + \delta\,(321) = \tau_2 + \Sigma\,\delta\,\angle = \tau_2 + .000111$, and $K_{21}\,\tau_{21} = 2.14\,\tau_2 + .000238$, as given in columns (6) and (7). Likewise, the value of $K_{34}\,\tau_{34}$ (joint 3) is read at once as $2.50\,\tau_3 - .000737$, etc., etc.

313. (*c*) *Formulation of Equations.*—We will now proceed to formulate an equation for each joint after eq. (16).

Joint 1.—For this joint, eq. (16) becomes

$$2\,(K_{12}\tau_{12} + K_{13}\tau_{13}) + K_{21}\tau_{21} + K_{31}\tau_{31} = 0.$$

The quantity in parenthesis is the sum of all the values of $K\tau$ for joint 1. These are conveniently summed up in the table, Columns (6) and (7), and the result there given is $4.64\,\tau_1 + .000230$. This is to be multiplied by two. The values of $K_{21}\,\tau_{21}$ and $K_{31}\,\tau_{31}$ are obtained directly from the table opposite members 2–1 and 3–1 of joints 2 and 3. They are $2.14\,\tau_2 + .000238$ and $2.50\,\tau_3$. Adding the absolute terms we have the equation

$$9.28\,\tau_1 + 2.14\,\tau_2 + 2.50\,\tau_3 = -.000698. \quad . \quad . \quad . \quad (a)$$

Joint 2.—The equation for this joint is

$$2\,(K_{24}\tau_{24} + K_{23}\tau_{23} + K_{21}\tau_{21}) + K_{42}\tau_{42} + K_{32}\tau_{32} + K_{12}\tau_{12} = 0.$$

The quantity in parenthesis is the summation opposite joint 2 in Columns (6) and (7), and is $7.06\,\tau_2 + .000393$. The other values of $K\tau$ are found opposite the respective members, 4–2, 3–2, and 1–2.

In formulating the equation the terms may be conveniently written down as follows:

$$\begin{aligned}(2\,\Sigma\,K\,\tau) &= 14.12\,\tau_2 + .000786\\ (K_{42}\,\tau_{42}) &= 2.14\,\tau_4 + .000197\\ (K_{32}\,\tau_{32}) &= 2.78\,\tau_3 - .000412\\ (K_{12}\,\tau_{12}) &= 2.14\,\tau_1\end{aligned}$$

Whence by adding absolute terms we have

$$14.12\,\tau_2 + 2.14\,\tau_4 + 2.78\,\tau_3 + 2.14\,\tau_1 = -.000571. \quad . \quad (b)$$

Joint 3.—Noting that the list of members in Column (5), opposite joint 3, may be strictly followed in finding the various single terms $K\,\tau$, we may write out at once the quantities for joint 3 as follows:

$$\begin{aligned}&15.56\,\tau_3 - .002298\\ &2.50\,\tau_1 + .000230\\ &2.78\,\tau_2 + .000155\\ &2.50\,\tau_4\\ &\qquad\qquad -.001913\end{aligned}$$

whence

$$15.56\,\tau_3 + 2.50\,\tau_1 + 2.78\,\tau_2 + 2.50\,\tau_4 = +.001913 \quad . \quad (c)$$

Joint 4.—In the same manner,

$$\begin{aligned}&9.28\,\tau_4 + .000394\\ &2.50\,\tau_3 - .000737\\ &2.14\,\tau_2\\ &\qquad\qquad -.000343\end{aligned}$$

whence

$$9.28\,\tau_4 + 2.50\,\tau_3 + 2.14\,\tau_2 = +.000343. \quad . \quad . \quad . \quad (d)$$

314. (*d*) *Solution of the Equations.*—Arranging the equations in systematic order, we have

$$\begin{aligned}(a)\quad & 9.28\,\tau_1 + 2.14\,\tau_2 + 2.50\,\tau_3 = -.000698\\ (b)\quad & 2.14\,\tau_1 + 14.12\,\tau_2 + 2.78\,\tau_3 + 2.14\,\tau_4 = -.000571\\ (c)\quad & 2.50\,\tau_1 + 2.78\,\tau_2 + 15.56\,\tau_3 + 2.50\,\tau_4 = +.001913\\ (d)\quad & 2.14\,\tau_2 + 2.50\,\tau_3 + 9.28\,\tau_4 = +.000343\end{aligned}$$

The solution may be made in any convenient manner, but the order of elimination used here will generally be found convenient for longer problems where it is a matter of some importance.

From (*a*), (*b*), and (*c*), we get

$$(a') \quad \tau_1 + .231\,\tau_2 + .269\,\tau_3 = -.0000752$$
$$(b') \quad \tau_1 + 6.60\,\tau_2 + 1.299\,\tau_3 + \tau_4 = -.0002668$$
$$(c') \quad \tau_1 + 1.112\,\tau_2 + 6.224\,\tau_3 + \tau_4 = +.0007652$$

Then subtracting (*a'*) from (*b'*) and (*a'*) from (*c'*), we have

$$(e) \quad 6.37\,\tau_2 + 1.030\,\tau_3 + \tau_4 = -.0001916$$
$$(f) \quad .881\,\tau_2 + 5.955\,\tau_3 + \tau_4 = +.0008404$$

Then from (*e*), (*f*), and (*d*) we get, in a similar manner,

$$(e') \quad \tau_2 + .1617\,\tau_3 + .157\,\tau_4 = -.0000301$$
$$(f') \quad \tau_2 + 6.760\,\tau_3 + 1.135\,\tau_4 = +.0009540$$
$$(d') \quad \tau_2 + 1.168\,\tau_3 + 4.337\,\tau_4 = +.0001603$$

$$(g) \quad 6.598\,\tau_3 + .978\,\tau_4 = +.0009841$$
$$(h) \quad 1.006\,\tau_3 + 4.180\,\tau_4 = +.0001904$$

Then from (*g*) and (*h*)

$$(g') \quad \tau_3 + .148\,\tau_4 = +.0001492$$
$$(h') \quad \tau_3 + 4.155\,\tau_4 = +.0001893$$

$$4.007\,\tau_4 = +.0000401$$
$$\tau_4 = +.0000100$$

Then, substituting back in (*g'*), (*e'*), and (*a'*), we get the following values:

$$\tau_3 = +.0001475$$
$$\tau_2 = -.0000555$$
$$\tau_1 = -.0001021$$

Where the structure and the load are symmetrical, as in this case, it is necessary to carry the equations only as far as the centre of the truss, as the values of τ on the right will be equal to the corresponding values

on the left, but of opposite sign. Where a vertical member is placed at the centre, as member 2–3, we have, from symmetry, $\tau_{23} = 0$, and $\tau_{32} = 0$. But from the table, joint 2, Column (4), we have $\tau_{23} = \tau_2 + .0000555$, whence $\tau_2 = -.0000555$. Likewise $\tau_{32} = 0 = -.0001475$, whence $\tau_3 = +.0001745$. Then a single equation, eq. (*a*), p. 436, is sufficient to determine τ_1. In the preceding analysis the work has been fully carried out as would be necessary for unsymmetrical conditions.

315. (*e*) *Calculation of the Several Values of* τ *and of the Bending Moments.*—The values of τ_1, τ_2, τ_3, and τ_4 are inserted in Column (8) of the table, opposite the first member of the respective joint. The other values of τ are found by adding to these, the values of $\Sigma\, \delta\, \angle$, given in Column (4). Thus $\tau_{13} = \tau_1 + .000092 = -.0000101$; $\tau_{23} = \tau_2 + .0000555 = 0$; $\tau_{21} = \tau_2 + .0001110 = +.0000555$, etc. Note that values of τ in opposite halves of the truss are alike but of opposite sign.

The bending moments are found from eq. (14), $M_{nm} = \frac{2EI}{l}(2\tau_{nm} + \tau_{mn}) = 2EK(2\tau_{nm} + \tau_{mn})$. In Column (9) are given values of $2\tau_{nm} + \tau_{mn}$ for each member. Thus for 1–2 the value is $2\tau_{12} + \tau_{21} = -.0002042 + .0000555 = -.0001487$; for member 1–3 the value is $\tau_{13} + \tau_{31} = -.0000202 + .0001475 = +.0001273$, etc. The values of the moments are then equal to $2EK$ times the values in Column (9). The results are given in Column (10). The slight differences between the values of M_{12} and M_{13}, and between M_{43} and M_{42} are due to inaccuracies in the calculations.

Fibre stresses are readily determined from the moments, or from eq. (18), but the calculations will not be carried further in this problem. From the signs of the moments and the adopted scheme, illustrated in Fig. 8, the true directions of bending are found to be as indicated in Fig. 13.

316. *General Remarks.*—It is seen that in calculating the values of $\delta\, \angle$ the quantity E enters as a divisor, giving very small quantities to deal with. These appear again in Column (7), from which are obtained the absolute terms of all the equations, or the right-hand members of eqs. (*a*), (*b*), etc., Art. 313. Then in calculating the values of M in Column (10), the quantity E enters as a multiplier. It will

save time and also give values more convenient to handle if the quantity E be omitted in both of these operations. The resulting values in Columns (3), (4), (7), (8), and (9) will then be E times the true angles. The values of M in Column (10) are then obtained by multiplying those

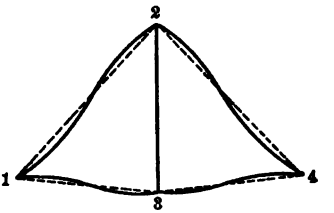

FIG. 13.

of Column (9) by $2K$. In case of eccentricity of the axial or primary stresses, causing an external moment M_n, the quantity $\frac{M_n}{2}$ is to be added to the absolute term instead of $\frac{M_n}{2E}$, as given in eq. (17).

Again, the results usually desired are the maximum fibre stresses rather than the moments M. These are given by eq. (18). They are obtained from Column (9) by multiplying by $\frac{2Ec}{l}$, or if E is omitted in the previous calculations, the multiplier is $\frac{2c}{l}$. For symmetrical sections this multiplier is h/l, or the ratio of depth to length of member. Other important deductions are discussed in Art. 324.

317. The Secondary Stresses in a Pratt Truss.—To fully determine the maximum fibre stresses in all members of a truss, due to both primary and secondary stresses, it is necessary to calculate the secondary stresses throughout, for a single load at each joint. The results can then be combined with the primary stresses in any desired manner and the true maximum values determined. Correct maximum results will not always be reached by adding the maximum secondary stress to the maximum primary stress, as these maxima may not occur simultaneously. Combined influence lines furnish a ready method of exact calculation for any kind of loading. To illustrate these points, and at the same time the application of the pre-

ceding methods to a larger problem, a complete solution will be made of a six-panel Pratt truss.

The general dimensions are shown in Fig. 14, and the various elements needed in the calculations are given in Table A. The joints

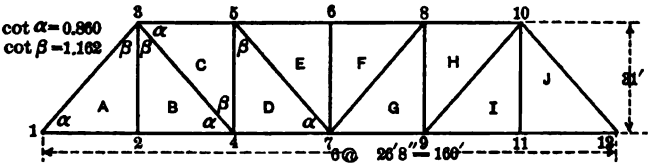

FIG. 14.

are numbered consecutively as shown, for convenience in the work of formulating and solving the equations. In selecting the order of numbering the same order may be adopted as is followed in drawing

TABLE A.

Member.	Sectional Area sq. in.	Length Inches.	I	c Inches.	$K = \frac{I}{l}$	$\frac{c}{l}$	Make-up of Section.
1–2	29.44	320	1218	9.12	3.80	.0285	4 L's 4″ × 4″ × $\frac{3}{8}$ 2 Pls. 18″ × $\frac{1}{2}$
2–4	29.44	320	1218	9.12	3.80	.0285	4 L's 4″ × 4″ × $\frac{3}{8}$ 2 Pls. 18″ × $\frac{1}{2}$
4–7	45.48	320	1907	9.12	5.96	.0285	4 L's 4″ × 4″ × $\frac{5}{8}$ 2 Pls. 18″ × $\frac{3}{4}$
1–3	58.49	490.7	4490	9.54 14.08	9.15	.0194 .0287	1 Cov. Pl. 26″ × 9/16″ 2 L's 3½″ × 3½ × ½″ 2 L's 5″ × 3½″ × $\frac{5}{8}$″ 2 Webs. 22″ × $\frac{5}{8}$″
3–5	52.35	320	3978	9.19 14.43	12.43	.0287 .0451	1 Cov. Pl. 26″ × 9/16″ 2 L's 3½″ × 3½″ × $\frac{3}{8}$″
5–6	52.35	320	3978	9.19 14.43	12.43	.0287 .0451	2 L's 5″ × 3½″ × ½″ 2 Webs. 22″ × 9/16″
3–2	16.00	372	94.8	5.4	0.255	.0145	4 L's 5″ × 3½″ × ½″
3–4	29.42	490.7	805.4	7.5	1.64	.0153	2 ['s 15″ — 50 lb.
5–4	26.48	372	750.2	7.5	2.016	.0202	2 ['s 12″ — 45 lb.
5–7	20.58	490.7	358.6	6.0	.731	.0122	2 ['s 12″ — 35 lb.
6–7	14.70	372	288.0	6.0	.774	.0161	2 ['s 12″ — 27 lb.

a stress diagram, beginning at joint 1. The triangles are lettered in regular order.

To make a complete solution, the stresses will be separately determined for joint loads at 7, 9, and 11, and to simplify the calculations these joint loads will be so taken as to give the same reaction at the left end in each case. Joint loads will therefore be assumed as follows: 1,000 lbs. at 7, 1,500 lbs. at 9, and 3,000 lbs. at 11. For all three cases, the primary stresses in the left half of the truss will be the same. The final values of secondary stress can readily be reduced to the same

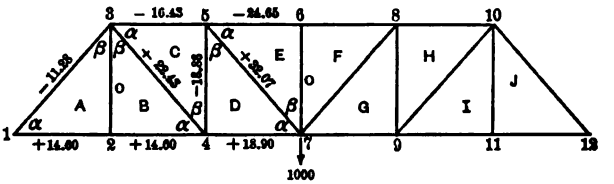

FIG. 15.

TABLE B1.

CALCULATION OF $\delta \angle$, CASE I.

Triangle.	Angle.	Factor of cot α (.8602).	Factor of cot β (1.162).	$\delta \angle$.
A	1	.....	0+11.28	+13.11
	2	−11.28−14.60	−11.28−0	−35.37
	3	+14.60+11.28	.....	+22.26
B	2	+22.43−14.60	+22.43−0	+32.80
	3	+14.60−22.43	.....	− 6.74
	4	.....	0−22.43	−26.06
C	3	.....	−18.88−22.43	−48.00
	4	−16.43−22.43	.....	−33.42
	5	+22.43+16.43	+22.43+18.88	+81.42
D	4	+32.07−18.90	+32.07+18.88	+70.55
	5	+18.90−32.07	.....	−11.33
	7	.....	−18.88−32.07	−59.22
E	5	.....	0−32.07	−37.27
	6	+32.07+24.65	+32.07−0	+86.05
	7	−24.65−32.07	.....	−48.78

basis by dividing by the joint load assumed in each case. The order of procedure will be the same as in the previous problem, but all three cases will be carried along simultaneously.

318. (*a*) *Calculation of Changes of Angles* ($\delta\angle$).—There being but two different angles in this truss (other than 90°), they will be called α and β in general, as shown in Fig. 14.

Case I. Load of 1,000 *lbs. at Joint* 7.—The unit stresses *s* are first computed. These are conveniently shown on a diagram of the truss,

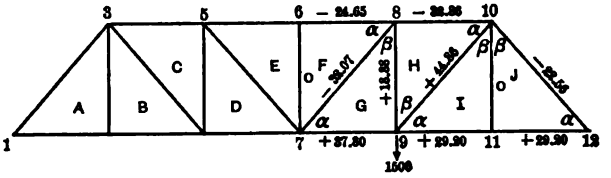

FIG. 16.

TABLE B2.

CALCULATION OF $\delta\angle$, CASE II.

Triangle.	Angle.	Factor of cot α (.8602).	Factor of cot β (1.162).	$\delta\angle$.
A to *E*....	Same as	in Table B1.		
F....	6	−32.07+24.65	−32.07−0	− 43.64
	7	−24.65+32.07	.....	+ 6.38
	8	.....	0+32.07	+ 37.26
G....	7	.....	+18.88+32.07	+ 59.20
	8	+37.80+32.07	.....	+ 60.10
	9	−32.07−37.80	−32.07−18.88	−119.30
H....	8	+44.86+32.86	+44.86−18.88	+ 97.05
	9	−32.86−44.86	.....	− 66.85
	10	.....	+18.88−44.86	− 30.20
I	9	.....	0−44.86	− 52.12
	10	+29.20−44.86	.....	− 13.48
	11	+44.86−29.20	+44.86−0	+ 65.60
J	10	+29.20+22.56	.....	+ 44.52
	11	−22.56−29.20	−22.56−0	− 70.74
	12	.....	0+22.56	+ 26.22

NOTE.—Values of $\delta\angle$ for triangles I and J are twice the values for triangles A and B of Table B1.

Fig. 15. Then in Table B1 are given in tabular form the calculations of the changes of angle, arranged by triangles. Each angle is denoted by the apex number of the triangle in question. The values of $\delta \angle$ for the right half are the same as those for the left half and need not be recorded here.

Case II. Load of 1,500 *lbs. at Joint* 9.—The necessary calculations

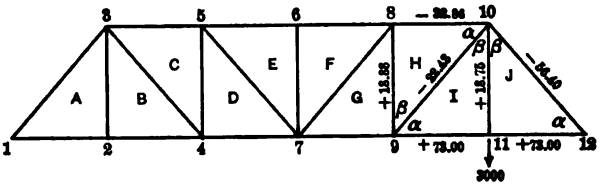

FIG. 17.

TABLE B3.

CALCULATION OF $\delta \angle$, CASE III.

Triangle.	Angle.	Factor of cot α (.8602).	Factor of cot β (1.162).	$\delta \angle$.
A to *G*...	Same as in	Table B2.		
H....	8	−22.43+32.86	− 22.43− 18.88	− 39.01
	9	−32.86+22.43	.....	− 8.98
	10	.....	+ 18.88+ 22.43	+ 47.99
I....	9	.....	+ 187.5+ 22.43	+244.0
	10	+73.00+22.43	.....	+ 82.09
	11	−22.43−73.00	− 22.43− 187.5	−326.09
J....	10	+73.00+56.40	.....	+111.3
	11	−56.40−73.00	− 56.40−187.5	−394.8
	12	.....	+187.5 + 56.40	+283.5

are shown in Fig. 16 and Table B2. Up to triangle *E* the results are the same as in Table B1, as the stresses are the same.

Case III. Load of 3,000 *lbs. at Joint* 11.—The values for triangles *A* to *G* will be found in Tables B1 and B2. The calculations for the remaining angles are given in Fig. 17 and Table B3.

319. (*b*) *Calculation of* $\Sigma \delta \angle$ and $K \Sigma \delta \angle$ *at the Several Joints.*—The calculation and tabulation of these quantities for all three cases are

readily combined in Table C, p. 446. The values of K are the same for all cases. Furthermore, in all respects, Case II is the same as Case I up to joint 5, and Case III the same as Case II up to joint 7. The values for Case I need not be carried beyond joint 7 because of symmetry of conditions.

320. (*c*) *Formulation of Equations.*—From Table C, the equations are written out as explained in the preceding example, using the values of Columns (3), (7), (10), and (13). Thus for Case I, the equation for joint 3 is obtained as follows, from Columns (3) and (7):

$2 \times 23.48\ \tau_3 -$	2×390.1		(See summations for joint 3)
$+ 12.43\ \tau_5 +$	408.0		(See member 5–3 under joint 5)
$+ 1.64\ \tau_4 -$	42.7		(See member 4–3 under joint 4)
$+ 0.26\ \tau_2 -$	9.2		(See member 2–3 under joint 2)
$+ 9.15\ \tau_1$			(See member 1–3 under joint 1)

whence

$$9.15\ \tau_1 + .26\ \tau_2 + 46.96\ \tau_3 + 1.64\ \tau_4 + 12.43\ \tau_5 = + 424.1.$$

The list of members under joint 3, Column (2), is used for finding the various terms in the table after the first. For Cases II and III the equations for joints 1 to 5 are identical with those for Case I.

For joints beyond No. 5, the equations will be different for Cases I and II, and beyond joint 7 they will be different for each case; but it will be noted that the coefficients of τ are functions of K only and are the same for *all cases*. Hence the equations, where different, will differ only in the absolute terms. The equations for all three cases can then conveniently be arranged in a single table. Table *D* contains all the equations for all the cases thus formulated.

321. (*d*) *Solution of Equations.*—The solution of the equations for all three cases may be carried along together as far as necessary. The same general method of elimination is used as in Art. 314. The entire work is given in Table E, the final values of τ for the three cases being given at the foot of the table.

The process is as follows: Eqs. (1), (2), and (3) of Table D, containing τ_1, are each divided by the coefficient of τ_1, giving eqs. (1′), (2′), and (3′) of Table E. Eq. (1′) is then subtracted from (2′) and from (3′), giving (*a*) and (*b*), and eliminating τ_1. These two

TABLE C.

CALCULATION OF $\Sigma\delta\angle$ AND $K\Sigma\delta\angle$.

Joint. (1)	Member. (2)	K (3)	Angle. (4)	Case I (Load at 7). $\delta\angle$. (5)	Case I (Load at 7). $\Sigma\delta\angle$. (6)	Case I (Load at 7). $K\times\Sigma\delta\angle$. (7)	Case II (Load at 9). $\delta\angle$ (8)	Case II (Load at 9). $\Sigma\delta\angle$. (9)	Case II (Load at 9). $K\times\Sigma\delta\angle$. (10)	Case III (Load at 11). $\delta\angle$. (11)	Case III (Load at 11). $\Sigma\delta\angle$. (12)	Case III (Load at 11). $K\times\Sigma\delta\angle$. (13)
1	13	9.15	.....	.....	.....	.....						
	12	3.80	312	+13.11	+ 13.11	+ 49.82						
		12.95				+ 49.82						
2	21	3.80	.....	.....	.....	.....						
	23	.26	123	−35.37	− 35.37	− 9.20						
	24	3.80	324	+32.80	− 2.57	− 9.76						
		7.86				− 18.96						
3	35	12.43	.....	.....	.....	.....						
	34	1.64	534	−48.00	− 48.00	− 78.72						
	32	.26	432	− 6.74	− 54.74	− 14.23						
	31	9.15	231	+22.26	− 32.48	− 297.2						
		23.48				− 390.15						
4	42	3.80	.....	.....	.....	.....						
	43	1.64	243	−26.06	− 26.06	− 42.73						
	45	2.02	345	−33.42	− 59.48	− 120.15						
	47	5.96	547	+70.55	+ 11.07	+ 65.95						
		13.42				− 96.93						
5	56	12.43	.....	.....	.....	.....						
	57	.73	657	−37.27	− 37.27	− 27.21						
	54	2.02	754	−11.33	− 48.60	− 98.15						
	53	12.43	453	+81.42	+ 32.82	+ 408.0						
		27.61				+ 282.6						
6	68	12.43	.....	.....	.....	.....						
	67	.77	867	+86.05	+ 86.05	+ 66.25	−43.64	−43.64	− 33.60			
	65	12.43	765	+86.05	+172.10	+2139.2	+86.05	+42.41	+527.2			
		25.63				+2205.4			+493.6			

Same as I.

Same as II.

7	74	5.96	.....	.....	.....	.....	.....	.....	.....	.....			
	75	.73	475	−59.22	− 59.22	− 43.25	− 59.22	− 59.22	− 43.25				
	76	.77	576	−48.78	−108.00	− 83.15	− 48.78	−108.00	− 83.15				
	78	.73	678	−48.78	−156.78	− 114.45	+ 6.38	−101.62	− 74.18				
	79	5.96	879	−59.22	−216.00	−1287.5	+ 59.20	− 42.42	− 252.8				
		14.15				−1528.4			− 453.3				
8	8 10	12.43	.....	.....	.....	.....	.....	.....	.....	.....	.....	.....	.....
	89	2.02	10.8.9	.....	.....	.....	+ 97.05	+ 97.05	+ 196.0	− 39.01	− 39.01	− 78.8	
	87	.73	987	.....	.....	.....	+ 60.10	+157.15	+ 114.7	+ 60.10	+ 21.09	+ 15.4	
	86	12.43	786	.....	.....	.....	+ 37.26	+194.41	+2416.5	+ 37.26	+ 58.35	+ 725.5	
		27.61							+2727.2			+ 662.1	
9	97	5.96	.....	.....	.....	.....	.....	.....	.....	.....	.....	.....	.....
	98	2.02	798	.....	.....	.....	−119.30	−119.30	− 241.0	−119.30	−119.30	− 241.0	
	9 10	1.64	8.9.10	.....	.....	.....	− 66.85	−186.15	− 305.3	− 8.98	−128.28	− 210.4	
	9 11	3.80	10.9.11	.....	.....	.....	− 52.12	−238.27	− 905.5	+ 24.40	+115.72	+ 439.7	
		13.42							−1451.8			− 11.7	
10	10 12	9.15	.....	.....	.....	.....	.....	.....	.....	.....	.....	.....	.....
	10 11	.26	12.10.11	.....	.....	.....	+ 44.52	+ 44.52	+ 11.57	+111.31	+111.31	+ 28.9	
	10 9	1.64	11.10.9	.....	.....	.....	− 13.48	+ 31.04	+ 50.90	+ 82.09	+193.40	+ 317.3	
	10 8	12.43	9.10.8	.....	.....	.....	− 30.20	+ .84	+ 10.44	+ 47.99	+241.39	+3002.	
		23.48							+ 72.91			+3348.2	
11	11 9	3.80	.....	.....	.....	.....	.....	.....	.....	.....	.....	.....	.....
	11 10	.26	9.11.10	.....	.....	.....	+ 65.60	+ 65.60	+ 17.05	−326.09	−326.09	− 84.8	
	11 12	3.80	10.11.12	.....	.....	.....	− 70.74	− 5.14	− 19.53	−394.8	−720.89	−2739.4	
		7.86							− 2.48			−2824.2	
12	12 11	3.80	.....	.....	.....	.....	.....	.....	.....	.....	.....	.....	.....
	12 10	9.15	11.12.10	.....	.....	.....	+ 26.22	+ 26.22	+ 239.9	+283.5	+283.5	+2593.	
		12.95							+ 239.9			+2593.	

TABLE D.

EQUATIONS FOR CASES I, II, AND III.

No. of Joint or Eq.	First Member of Equation.	Absolute Terms.		
		Case I.	Case II.	Case III.
1	$25.90\,\tau_1+3.80\,\tau_2+9.15\,\tau_3\ldots\ldots=$	+ 197.6	.....	.....
2	$3.80\,\tau_1+15.72\,\tau_2+.26\,\tau_3+3.80\,\tau_4\ldots\ldots=$	+ 2.33	.....	.....
3	$9.15\,\tau_1+.26\,\tau_2+46.96\,\tau_3+1.64\,\tau_4+12.43\,\tau_5\ldots=$	+ 424.1	.....	.....
4	$3.80\,\tau_2+1.64\tau_3+26.84\,\tau_4+2.02\,\tau_5+5.96\,\tau_7\ldots=$	+ 380.5	.....	.....
5	$12.43\,\tau_3+2.02\,\tau_4+55.22\,\tau_5+12.43\,\tau_6+.73\,\tau_7\ldots=$	−2541.0	− 929.0	.....
6	$12.43\,\tau_5+51.26\,\tau_6+.77\,\tau_7+12.43\,\tau_8\ldots\ldots=$	.....	−3320.5	−1629.5
7	$5.96\,\tau_4+.73\,\tau_5+.77\,\tau_6+28.30\,\tau_7+.73\,\tau_8+5.96\,\tau_9=$	.....	+ 786.8	+ 886.1
8	$12.43\,\tau_6+.73\,\tau_7+55.22\,\tau_8+2.02\,\tau_9+12.43\,\tau_{10}\ldots=$	.....	−5149.7	−4011.0
9	$5.96\,\tau_7+2.02\,\tau_8+26.84\,\tau_9+1.64\,\tau_{10}+3.80\,\tau_{11}\ldots=$	.....	+2909.5	+ 37.7
10	$12.43\,\tau_8+1.64\,\tau_9+46.96\,\tau_{10}+.26\,\tau_{11}+9.15\,\tau_{12}\ldots=$	.....	− 97.5	−8994.2
11	$3.80\,\tau_9+.26\,\tau_{10}+15.72\,\tau_{11}+3.80\,\tau_{12}\ldots\ldots=$	.....	+ 898.9	+5179.8
12	$9.15\,\tau_{10}+3.80\,\tau_{11}+25.90\,\tau_{12}\ldots\ldots\ldots\ldots=$	.....	− 460.3	−2446.6

equations are then divided by the coefficient of τ_2, giving (a') and (b'). Then in Table D, eq. (4) is also divided by the coefficient of τ_2, giving (4′) of Table E. Then, as before, (a') is subtracted from (b') and also from (4′), giving (c) and (d) and eliminating τ_2. Then τ_3 is eliminated in the same way. To eliminate τ_4 we use eqs. (e), (f), and No. 7, instead of No. 6, as the latter does not contain τ_4 while the former does. Then eq. (6) is next used in eliminating τ_5, after which the equations are used in regular order. Finally the values of τ_{12}, for Cases II and III, are obtained in eq. (u'). Having these, the values of τ_{11} are most readily obtained from eq. (s'), then τ_{10} from (q'), etc. The several values are given at the foot of the table. The process for Case I is carried only so far as to eliminate τ_4, giving eq. (g), from which (g') is obtained, which contains τ_5, τ_6, and τ_7. From symmetry we know that the member 6–7 has no moment at either end, hence $\tau_{67} = 0$, and $\tau_{76} = 0$. From Table C, joint 6, we have $\tau_{67} = \tau_6 +$

TAB

Solution

No of Eq	τ_1	τ_2	τ_3	τ_4	τ_5	τ_6	τ_7
1'	1	.147	.353				
2'	1	4.137	.068	1.000			
3'	1	.0884	5.130	.1792	1.358		
(a)		3.990	- .285	1.000			
(b)		- .1186	4.777	.1792	1.358		
a'		1	- .071	.251			
b'		-1	40.30	1.511	11.45		
4'		1	.432	7.063	.532		1.568
(c)			40.229	1.762	11.45		
(d)			.503	0.812	.532		1.568
c'			1	.044	.285		
d'			1	13.54	1.058		3.117
5'			1	.103	4.445	1	.059
(e)				13.496	.773		3.117
(f)				.119	4.16	1	.059
e'				1	.057		.231
f'				1	34.96	8.41	.495
7'				1	.1225	.129	4.747
(g)					34.90	8.41	.205
(h)					.0855	.129	4.516
g'					1	.241	.007
h'					1	1.972	68.90
6'					1	4.125	.062
(i)						1.731	68.89
(j)						3.884	.054
i'						1	38.82
j'						1	.0139
8'						1	.0588
(k)							38.81
(l)							.0449
k'							1
l'							1
9'							1
(m)							
(n)							
m'							
n'							
10'							
(o)							
(p)							
o'							
p'							
11'							
(q)							
(r)							
q'							
r'							
12'							
(s)							
(t)							
s'							
t'							
(u)							
u'							
Case	τ_1	τ_2	τ_3	τ_4	τ_5	τ_6	τ_7
I	+1.21	+1.89	+17.47	- 8.75	- 31.67	- 66.05	+103.0
II	+4.54	-4.40	+10.59	+13.56	-10.91	- 39.44	+ 6.30
III	+3.65	-2.30	+12.23	+ 5.61	-15.48	-21.60	+41.83

LE E

of Equations

τ_8	τ_9	τ_{10}	τ_{11}	τ_{12}	Absolute Terms Case I	Case II	Case III
					+ 7.63 + .61 + 46.35		
					- 7.02 + 38.72		
					- 1.76 +326.7 +100.13		
					+324.94 +101.89		
					+ 8.07 + 202.5 -204.4	+ 8.07 + 202.5 - 74.7	
					+194.4 -212.5	+194.4 - 82.8	
.122					+ 14.4 -1786.0	+ 14.4 -696.0 +132.1	+ 14.4 - 696.6 + 148.7
.122					-1800.4	-710.4 +117.7	-710.4 +134.3
1.87 1	15.26				- 51.58	- 20.36 +1790. -267.2	- 20.36 +2049. - 131.1
1.87 1	15.26					+1816.4 - 246.8	+2069.4 - 110.7
.081 .257 1.445	8.815 .1625	1				+1049.5 - 63.55 -414.5	+1195.5 - 28.5 - 322.7
.824 1.188	8.815 .1625	1				+1113.0 -351.0	+1224.0 -294.2
.020 5.30 338	.221 3.670 4.503	22.27 .275	.637			+ 27.96 -7817. +488.	+ 30.75 -6555. - 6.32
8.28 .318	3.398 4.282	22.27 .275	.637			-7845. +460.	-6585.8 - 24.43
1 1 1	.036 13.405 .131	.238 .864 3.777	2.006 .021	.736		- 84.10 +1447. - 7.85	- 70.60 - 78.83 - 723.5
	13.429 .095	.626 3.538	2.006 .021	.736		+1531.1 + 76.25	- 6.23 -652.9
	1 1 1	.0466 37.04 .0684	.149 .219 4.135	7.703 1		+ 114.0 + 798. +236.7	- .46 -6835. +1363.5
		36.99 .0218	.070 3.986	7.703 1		+684. +122.7	-6835. +1364.
		1 1 1	.0019 1828. .4153	.208 45.90 2.830		+ 18.50 +5627. - 50.30	- 184.8 +62550. - 267.2
			1828. .4134	45.69 2.622		+5068.5 - 68.80	+62735. - 82.4
			1 1	.250 6.34		30.70 -166.4	+ 343.3 - 199.3
				6.09 1		-197.1 - 32.35	-542.6 - 89.1
ues of τ							
τ_8	τ_9	τ_{10}	τ_{11}	τ_{12}			
- 94.01 - 29.04	+ 107.04 - 47.33	+ 25.17 - 166.9	+ 38.79 +365.6	- 32.35 - 89.10			

86.05, whence $\tau_6 = -86.05$. Also under joint 7, $\tau_{76} = \tau_1 - 108.0$, whence $\tau_7 = +108.0$. These values, substituted in eq. (g'), Case I, determine τ_5. Then τ_4 is obtained from eq. (e'), etc.

322. (*e*) *Calculation of Individual Deflection Angles and Fibre Stresses.*—Table E gives the values of the reference angle τ_n for each joint. The various angles, τ, for each member, are now obtained from Table C by adding to the reference angle for the joint, the value of $\Sigma\ \delta\ \angle$ for the member in question. Thus for member 5–4, Case I, the value of τ_{54} is $-31.7 - 48.6 = -80.3$; and for this member, Case II, it is $-10.9 - 48.6 = -59.5$. For the other end of this member, $\tau_{45} = -8.75 - 59.48 = -68.2$, and $+13.56 - 59.48 = -45.9$, respectively, for Cases I and II. These values of τ are given in Table F, for all members, and for all three cases. In following columns of the same table are given the values of $2\tau_{nm} + \tau_{mn}$ for use in the formula for fibre stress, eq. (18), $f_{nm} = \frac{2c}{l}(2\tau_{nm} + \tau_{mn})$. Thus for member 5–6 the value of this quantity is $2 \times \tau_{56} + \tau_{65}$, etc. Finally, the fibre stress for 1,000-lb. joint loads is obtained by multiplying these values by the quantity $\frac{2c}{l}$ for Case I, by $\frac{2c}{1.5l}$ for Case II, and by $\frac{2c}{3l}$ for Case III.

In regard to signs, the sign of τ indicates the direction of inclination at the joint, as shown in Fig. 9. Assuming all values positive, then the members will be bent toward the *right* with respect to the joint as centre as in Fig. 8. A plus sign for f will then signify a tensile stress in the fibre first met with in passing around the joint toward the right, the upper fibre in members on the right of the joint and the lower fibre in members on the left, etc. On account of the different effects of loads on different joints, it is desirable to use the sign for f in this way until the necessary combinations are made. For unsymmetrical members, such as the top chord and end post, two values of f are determined, the first being the stress in the fibre corresponding to the one referred to above, namely, in the fibre first met with in passing around the joint The second value is the stress in the opposite fibre.

TABLE F.

VALUES OF DEFLECTION ANGLES τ, AND FIBRE STRESSES f.

(The fibre stresses are for 1,000 lb. joint loads.)

Joints.	Member.	$\frac{c}{l}$	Case I (Load at 7). Load = 1,000 lbs. τ	Case I. $2\tau_{nm}+\tau_{mn}$	Case I. f	Case II (Load at 9). Load = 1,500 lbs. τ	Case II. $2\tau_{nm}+\tau_{mn}$	Case II. Load = 1,000 lbs. f	Case III (Load at 11). Load = 3,000 lbs. τ	Case III. $2\tau_{mn}+\tau_{nm}$	Case III. Load = 1,000 lbs. f
1	13	.0194 / .0287	+ 1.2	− 12.6	−0.49 / +0.72	+ 4.5	− 12.9	−0.33 / +0.50	+ 3.6	− 13.0	−0.17 / +0.25
	12	.0285	+14.3	+ 30.3	+1.73	+17.6	+ 30.9	+1.18	+16.8	+ 31.2	+0.59
2	21	.0285	+ 1.7	+ 17.7	+1.01	− 4.4	+ 8.8	+0.33	− 2.3	+ 12.2	+0.23
	23	.0145	−33.7	−104.6	−3.04	−39.8	−123.7	−2.39	−37.7	−117.8	−1.14
	24	.0285	− 0.9	− 10.5	−0.60	− 7.0	− 0.4	− .02	− 4.9	− 4.1	−0.08
3	35	.0287 / .0451	+17.5	+ 36.2	+2.07 / −3.26	+10.6	+ 3.1	+1.65 / −2.59	+12.2	+ 41.8	+0.80 / −1.26
	34	.0153	−30.5	− 95.8	−2.94	−37.4	− 87.3	−1.78	−35.8	− 92.0	−0.94
	32	.0145	−37.3	−108.3	−3.14	−44.2	−128.1	−2.48	−42.5	−122.7	−1.19
	31	.0287 / .0194	−15.0	− 28.8	−1.65 / +1.12	−21.9	− 39.2	−1.50 / +1.02	−20.2	− 36.9	−0.71 / +0.48
4	42	.0285	− 8.8	− 18.5	−1.05	+13.6	+ 20.2	+0.77	+ 5.6	+ 6.4	+0.12
	43	.0153	−34.8	−100.1	−3.07	−12.5	− 62.4	−1.27	−20.5	− 76.7	−0.78
	45	.0202	−68.2	−216.7	−8.75	−45.9	−151.4	−4.08	−53.9	−171.8	−2.31
	47	.0285	+ 2.3	+112.6	+6.42	+24.6	+ 55.6	+2.12	+16.7	+ 75.2	+1.43
5	56	.0287 / .0451	−31.7	+ 22.6	+1.30 / −2.05	−10.9	− 18.8	−0.72 / +1.13	−15.5	− 10.2	−0.20 / +0.31
	57	.0122	−68.9	− 89.0	−2.17	−48.2	−149.3	−2.43	−52.8	−122.9	−1.00
	54	.0202	−80.3	−228.8	−9.24	−59.5	−164.9	−4.44	−64.1	−182.0	−2.45
	53	.0451 / .0287	+ 1.2	+ 19.9	+1.78 / −1.14	+21.9	+ 54.4	+3.27 / −2.09	+17.3	+ 46.9	+1.41 / −0.90

6	68	.0287 .0451	− 86.0	−140.3	− 8.06 +12.65	− 39.4	+ 21.5	+0.82 −1.30	− 21.6	− 13.7	− 0.26 + 0.41
	67	.0161	0	0	0	− 83.1	−267.9	−5.76	− 65.2	−196.7	− 2.11
	65	.0451 .0287	+ 86.0	.....	+12.65 − 8.06	+ 3.0	− 5.0	−0.30 +0.19	+ 20.8	+ 26.1	+ 0.78 − 0.50
7	74	.0285	+108.	+218.3	+12.44	+ 6.3	+ 37.2	+1.42	+ 41.8	+100.3	+ 1.91
	75	.0122	+ 48.8	+ 28.7	+ 0.70	− 52.9	−154.0	−2.50	− 17.4	− 87.5	− 0.71
	76	.0161	0	0	0	−101.7	−287.2	−6.17	− 66.2	−197.6	− 2.12
	78	.0122	.....	.....	.....	− 95.3	−127.5	−2.07	− 59.8	−127.5	− 1.04
	79	.0285	.....	.....	.....	− 36.1	+ 34.8	+1.32	− 0.6	− 48.5	− 0.92
8	8 10	.0287 .0451	.....	.....	.....	− 94.0	−162.0	−6.20 +9.74	− 29.0	+ 16.4	+ 0.31 − 0.49
	89	.0202	.....	.....	.....	+ 3.0	− 6.2	−0.16	− 68.0	−302.7	− 4.08
	87	.0122	.....	.....	.....	+ 63.1	+ 31.0	−0.50	− 8.0	− 75.8	− 0.62
	86	.0451 .0287	.....	.....	.....	+100.4	+161.4	+9.71 −6.18	+ 29.5	+ 37.4	+ 1.13 − 0.72
9	97	.0285	.....	.....	.....	+107.0	+178.0	+6.77	− 47.3	− 95.3	− 1.81
	98	.0202	.....	.....	.....	− 12.3	− 21.5	−0.58	−166.6	−401.3	− 5.40
	9 10	.0153	.....	.....	.....	− 79.1	−102.0	−2.08	−175.6	−324.7	− 3.31
	9 11	.0285	.....	.....	.....	−131.2	−223.7	−8.51	+ 68.4	+502.4	+ 9.55
10	10 12	.0194 .0287	.....	.....	.....	+ 25.2	+ 44.1	+1.14 −1.69	−166.9	−139.4	− 1.80 + 2.67
	10 11	.0145	.....	.....	.....	+ 69.7	+243.8	+4.71	− 55.6	− 71.7	− 0.69
	10 9	.0153	.....	.....	.....	+ 56.2	+ 33.3	+0.68	+ 26.5	−122.6	− 1.25
	10 8	.0451 .0287	.....	.....	.....	+ 26.0	− 42.0	−2.53 +1.61	+ 74.5	+119.9	+ 3.61 − 2.30
11	11 9	.0285	.....	.....	.....	+ 38.8	− 53.6	−2.04	+365.6	+799.6	+15.20
	11 10	.0145	.....	.....	.....	+104.4	+278.5	+5.38	+ 39.5	+ 23.4	+ 0.23
	11 12	.0285	.....	.....	.....	+ 33.7	+ 35.0	+1.33	−355.3	−799.7	−15.20
12	12 11	.0285	.....	.....	.....	− 32.4	− 31.1	−1.18	− 89.1	−533.5	−10.13
	12 10	.0287 .0194	.....	.....	.....	− 6.2	+ 12.8	+0.47 −0.33	+194.4	+221.9	+ 4.25 − 2.88

TABLE G.

PRIMARY AND SECONDARY STRESSES FOR 1,000-LB. JOINT LOADS.

Member.		Secondary Stresses for 1,000 lbs. at 2	4	7	9	11	Maximum Primary Stress.	Total Secondary Stress for Maximum Primary.	Per cent Secondary of Maximum Primary.
End Post	13 T*	− 2.88	−0.33	− 0.49	−0.33	−0.17	−56.40	− 4.20	7.5
	13 B	+ 4.25	+0.49	+ 0.72	+0.50	+0.25		.....	
	31 T	− 1.80	+1.14	+ 1.12	+1.02	+0.48		.....	
	31 B	+ 2.67	−1.69	− 1.65	−1.50	−0.71		− 2.88	5.1
Top Chords	35 T	− 2.30	+1.61	+ 2.07	+1.65	+0.80	−65.72	.....	
	35 B	− 3.61	−2.53	+ 3.26	−2.59	−1.26		− 6.03	9.2
	53 T	+ 0.31	−6.20	− 1.14	−2.08	−0.90		−10.01	15.2
	53 B	− 0.49	+9.74	+ 1.78	+3.27	+1.41		.....	
	56 T	− 0.72	−6.18	+ 1.30	−0.72	−0.20	−74.00	− 6.52	8.8
	56 B	+ 1.13	+9.71	− 2.05	+1.13	+0.31		.....	
	65 T	− 0.26	+0.80	− 8.06	+0.19	−0.50		− 7.81	10.6
	65 B	+ 0.41	−1.30	+12.65	−0.30	+0.18		.....	
Bottom Chords	12	+10.13	+1.18	+ 1.73	+1.18	+0.59	+73.10	+14.81	20.3
	21	+15.20	−1.33	+ 1.01	+0.33	+0.23		+15.44	21.2
	24	−15.20	+2.04	− 0.60	−0.02	−0.08	+73.10	−13.86	19.0
	42	− 9.55	+8.51	− 1.05	+0.77	+0.12		− 1.20	1.6
	47	+ 1.81	−6.77	+ 6.42	+2.12	+1.43	+75.70	+ 5.01	6.6
	74	+ 0.92	−1.32	+12.44	+1.42	+1.91		+15.37	20.3
Hip Vertical	23	− 0.23	−5.38	− 3.04	−2.39	−1.14	+62.50	−12.18	19.5
	32	+ 0.69	−4.71	− 3.14	−2.48	−1.19		−10.83	17.3
Second Vertical	45	+ 5.40	+0.58	− 8.75	−4.08	−2.31	−37.76	−15.14	40.1
	54	+ 4.08	+0.16	− 9.24	−4.44	−2.45		−16.13	42.7
Middle Vertical	76	+ 2.12	+6.17	0	−6.17	−2.12	0	− 8.29	
	67	+ 2.11	+5.76	0	−5.76	−2.11		− 7.87	
Main Diagonal	34	+ 1.25	−0.68	− 2.94	−1.78	−0.94	+74.77	− 6.34	8.5
	43	+ 3.31	+2.08	− 3.07	−1.27	−0.78		− 3.04	4.1
2d Diagonal	57	+ 0.62	+0.50	− 2.17	−2.43	−1.00	+64.14	− 5.60	8.7
	75	+ 1.04	+2.07	+ 0.70	−2.50	−0.71		− 2.41	3.8

* *T* = top fibre; *B* = bottom fibre.

323. (*f*) *Total Secondary Stresses and Relation to Primary Stresses.*— From Table F the fibre stress f, in any member, due to 1,000 lbs., at any joint, can be obtained. Thus for member 2–4, load at 2, the stress is the same as in member 11–9, for load at 11, but with opposite sign, etc. In Table G, are brought together the values of the primary and secondary stresses at each end of each member of one-half of the truss, for a load of 1,000 lbs. at each joint. There is also given the total secondary stress which occurs for the same loading as the maximum primary stress. This is given both in pounds per sq. in. and also as percentage of the maximum primary stress. For the end post and top chord sections both top and bottom fibre stresses are given [indicated by "*T*" and "*B*"]. For the other members, only one value is given, this value being the stress in the fibre first met in passing around the joint in clockwise rotation. These signs correspond to those of Table F. As these members are all symmetrical, there will exist in all cases equal stresses of opposite sign from those given. The sign is therefore important only in combining results for loads on several joints.

It will be seen that for some members the secondary stresses are not a maximum when the primary stresses are a maximum, but inasmuch as the primary stress is generally much larger than the secondary stress, the total is generally a maximum when the primary stress is a maximum. On this basis the percentages in Table G are calculated. The secondary stresses in the chord members are generally of like sign for all loads, so that these stresses are a maximum, or nearly so, for full load. This relation is apt to be disturbed for loads applied near the member in question. Thus for member 4–7 all secondary stresses are plus except for load at 4, which gives a negative value. Again, in member 2–4, all values are negative except for load at 4.

In the web members the loading for maximum primary stress causes nearly the maximum secondary stress. In 4–5, for example, the maximum primary requires joints 7–11 to be loaded. This loading gives also maximum secondary stress. In member 7–5 the same is true, excepting for the small stress of + .70 for load at 7. In 4–3 there is also one exception to this rule. In the hip-vertical a fully loaded structure gives nearly the maximum secondary stress.

The true relations can best be seen by the use of influence lines.

Such lines have been drawn in Fig. 18 for some of the most important stresses. In these diagrams the primary stresses and the secondary stresses for both ends have been shown for members 1–2, 3–5, 4–7, and 4–5. The shaded areas show the secondary stresses at one end,

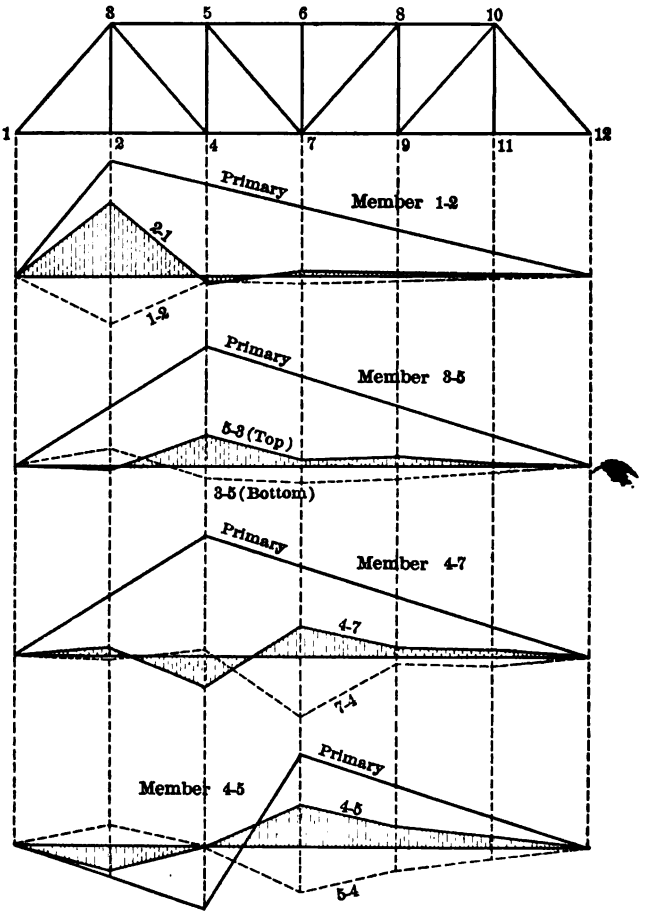

FIG. 18.

and the dotted lines those at the opposite end, the ordinates to the latter being plotted below the axis when of like sign to the primary stresses. The combined influence line for the sum of the two stresses may be used, if desired, for getting the exact maximum fibre stress

for any kind of loading. Sufficiently accurate results for most purposes will, however, be obtained by the assumption of equal joint loads, as in Table G, as the information desired is generally the percentage relation of the secondary stress to the primary stress, and this will be but slightly affected by the nature of the loading. Fig. 19

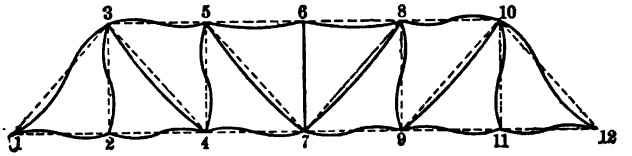

FIG. 19.

shows the nature of bending in the various members for a fully loaded structure.

The analysis here made assumes the loads applied at lower joints. For upper-joint loads the results will be somewhat different owing to the difference in stress in the vertical posts. For dead load, therefore, the results apply only for that portion applied at the lower joints, but as the load applied at the upper joints is generally small, compared to the total load, it is sufficiently accurate for most purposes to assume the dead load applied at the loaded chord. The greatest difference will occur at the end where the influence of the hip vertical is of primary importance.

324. General Remarks on the Foregoing Method of Calculation.— The calculation of secondary stresses, even of a small truss, has generally been considered by engineers a very laborious operation, requiring many days' time of a skilled computor. A systematic arrangement of the calculations, as illustrated by the preceding problem, will, to a large extent, obviate this objection to such calculations. By the method here given, a good computor, after becoming familiar with the process, can make a complete analysis by joint loads of an ordinary truss in less than two days' time. For larger structures of single intersection the labor involved increases about in proportion to the number of panels. The number of equations is increased, but in their solution the number of operations is increased only in the same proportion as the number of equations. Additional cases of loading, required by more numerous joints, require somewhat more work, but

it will be noted from Tables B and C that each new case involves only a small portion of the structure.

Very often sufficient information can be obtained by calculating the secondary stresses for a fully loaded structure. Such a loading gives the maximum stresses in all chord members, the end post, and generally in the hip vertical. This being a symmetrical load, only one-half of the truss need be considered; and the solution is similar to Case I of the preceding problem, involving only a few equations (five, in the case here considered), which is a matter of a few hours' work.

The order of elimination adopted in Table E is to be noted, especially with reference to the subtraction of one equation from another. Thus, referring to the group (c'), (d'), and (5′), eq. (c') is subtracted from (d'), and also from (5′). This procedure maintains the relative accuracy as far as possible, and also usually results in plus signs throughout, which is of much assistance in avoiding errors.

Again, assuming equations (4′), (5′), (6′), etc., to be correct, it will be found that the order of procedure here adopted is such that any error made in the calculations tends to become smaller as the work progresses, so that no great accuracy is necessary to secure satisfactory results. Furthermore, after the value of τ_{12} is obtained and the others are found by substituting back in (s'), (q'), (o'), etc., it is seen that here, also, any error of calculation tends to become less on account of the small values of the coefficients in these particular equations. These general relations are brought about from the fact that in the equation of equilibrium at any joint, given in Table D, the coefficient of the τ for the particular joint is generally much greater than that of any other τ. Thus in eq. (5) the coefficient of τ_5 is 55.22 compared to 12.43 for τ_3 and τ_6. This condition is sometimes made use of in solving the equations by successive approximations. By such method, approximate values are first found for the several τ's by omitting from each equation all values of τ excepting the one relating to the particular joint. Thus from eq. (1), we have $\tau_1 = 197.6/25.9$; and from eq. (2), $\tau_2 = 2.33/15.72$, etc. The approximate values thus found are then substituted in the several equations and more accurate values determined, etc. In view, however, of the readiness with which a correct solution may be reached, such approximate methods are of little or no advantage.

325. Approximate Methods of Calculation for a Limited Number of Joints.—When, for a particular loading, it is desired to determine the secondary stresses in a certain part of the structure, or in certain members only, very satisfactory results can be reached by neglecting the effect of the joints that are remote from the joint or joints in question. Results will be more accurate as more joints are included in the calculations, entire accuracy requiring the consideration of all the joints. It is generally sufficient, however, to include only one joint in each direction beyond those under consideration. Thus, in Fig. 20, if the stresses at joint 5, only, are desired, we may neglect all

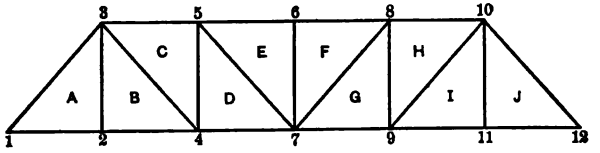

FIG. 20.

joints beyond 3, 4, 6, and 7. The small influence of τ_8 on τ_5 may be noted by referring to eqs. (g'), (f'), and (k') of Table E. The value of τ_8 appears to the extent of 2 per cent in τ_7 and 26 per cent in τ_6. Then τ_7 appears to the extent of 0.7 per cent in τ_5, and τ_6 to the extent of 24 per cent. Hence τ_8 comes into τ_5 to the extent of about 6 per cent.

EXAMPLES.—(1) As an example, this approximate method will be applied to joint 5 of the truss analyzed in the preceding articles, assuming the loading of Case I, that is, 1,000 lbs. at joint 7. Limiting our attention to joints 3, 4, 5, 6, and 7, we proceed to formulate the five equations. If this problem were to be solved from the beginning it would be necessary to calculate the values of $\delta \angle$ for triangles C, D, and E, and for the angles at 3, 4, 6, and 7 of triangles A, B, F, and G, so that in Table C, the values of $\delta \angle$ for all the joints considered would be known. Assuming this done the equations are written from Table C as follows.

Joint 5.—This equation is the same as given in Table D, and is used in complete form.

Joint 4.—This equation is made up in the same manner as before, except that the value of τ_{24} is omitted (including both τ_2 and the absolute term). The several terms are derived as follows:

from joint 4, $(\Sigma K + \Sigma \delta \angle)$	$26.84\ \tau_4 - 193.9$
from joint 3, member 3–4	$1.64\ \tau_3 - 78.7$
from joint 5, member 5–4	$2.02\ \tau_5 - 98.1$
from joint 7, member 7–4	$5.96\ \tau_7$

whence the equation

$$26.84\,\tau_4 + 1.64\,\tau_3 + 2.02\,\tau_5 + 5.96\,\tau_7 = + 370.7.$$

In the same manner we write out the equations for joints 3, 6, and 7 as follows:

$$(3) \quad 46.95\,\tau_3 + 12.43\,\tau_5 + 1.64\,\tau_4 = + 415.0$$
$$(6) \quad 51.26\,\tau_6 + .77\,\tau_7 + 12.43\,\tau_5 = - 4327.7$$
$$(7) \quad 28.3\,\tau_7 + 5.96\,\tau_4 + .73\,\tau_5 + .77\,\tau_6 = + 2951.8$$

Solving these equations as before, we get $\tau_5 = - 33.5$ as compared to a value of $- 31.7$ by the exact process.

(2) As another illustration take joint 11, Case II, as this value is relatively large. Consider only joints 9, 10, 11, and 12. The equations are written out as before. They are:

$$(9) \quad 26.84\,\tau_9 + 1.64\,\tau_{10} + 3.80\,\tau_{11} = - 293.9$$
$$(10) \quad 46.96\,\tau_{10} + 1.64\,\tau_9 + .26\,\tau_{11} + 9.15\,\tau_{12} = - 8994.2$$
$$(11) \quad 15.72\,\tau_{11} + 3.80\,\tau_9 + .26\,\tau_{10} + 3.80\,\tau_{12} = + 5180.$$
$$(12) \quad 25.90\,\tau_{12} + 9.15\,\tau_{10} + 3.80\,\tau_{11} = - 2446.6$$

Solving, we get $\tau_{11} = + 366.1$ as compared to $+ 365.6$ by the exact process.

The method of approximation here used assumes $\tau = 0$ at the ends of the members where the joints are not considered. This is equivalent to assuming these members to have one-half as much moment at the remote ends as at the joints considered. The results are probably more accurate than if the remote ends be assumed as hinged, and the equations are more easily formulated.

326. Effect of a Collision Strut upon the Secondary Stresses in the End Post.—Suppose in the truss analyzed in the preceding articles, a collision strut 2-a be used (Fig. 21), having a moment of inertia of

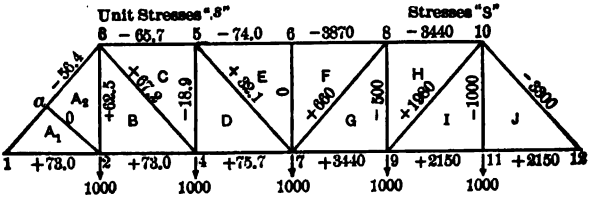

FIG. 21.

50 in⁴. Its effect upon the secondary stresses in the member 1–3 will be determined for a load of 1,000 lbs. at each joint. The angle 1–a–2 is 90°.

Fig. 21 gives in the right half the primary stresses S, and in the left half the unit stresses s. The stress in the member a–2 will be zero. The unit stresses in all members, excepting 3–4, 5–4, and 5–7,

may be taken from Table G, Art. 323. The calculations of $\delta \angle$'s requires the consideration of the two triangles, A_1 and A_2, and of member a–2.

The loading being symmetrical, it will not be necessary to carry the equations beyond joint 5, the values of τ_6 and τ_7 being obtained from the condition that both τ_{67} and $\tau_{76} = 0$. There will therefore be six equations, including that for joint a. These equations are as follows:

$$
\begin{aligned}
&(1)\quad 50.64\,\tau_1 + 21.52\,\tau_a + 3.80\,\tau_2 = -7{,}710\\
&(a)\quad 21.52\,\tau_1 + 75.30\,\tau_a + .206\,\tau_2 + 15.92\,\tau_3 = -14{,}400\\
&(2)\quad 3.80\,\tau_1 + .206\,\tau_a + 16.12\,\tau_2 + .26\,\tau_3 + 3.80\,\tau_4 = +2{,}372\\
&(3)\quad 15.92\,\tau_a + .26\,\tau_2 + 60.49\,\tau_3 + 1.64\,\tau_4 + 12.43\,\tau_5 = +2{,}518\\
&(4)\quad 3.80\,\tau_2 + 1.64\,\tau_3 + 26.84\,\tau_4 + 2.02\,\tau_5 + 5.96\,\tau_7 = +2{,}782\\
&(5)\quad 12.42\,\tau_3 + 2.02\,\tau_4 + 55.22\,\tau_5 + 12.43\,\tau_6 + .73\,\tau_7 = -8{,}194
\end{aligned}
$$

It will be noted that, except for members 1–3 and a–2, the left-hand members of the equations are the same as in Table D.

The solution of these equations gives the following results: $\tau_1 = -81.2$; $\tau_a = -194.1$; $\tau_2 = +153.7$; $\tau_3 = +121.6$; $\tau_4 = +524$; $\tau_5 = -150.7$. The stresses at joints 1, a, and 3 are as follows:

TABLE H.

STRESSES WITH COLLISION STRUT.

Member.		Secondary Stress.	Primary Stress.	Per cent Secondary to Primary.
End Post	1–a	$-4.3\,B$	-56.4	7.6
	a–1	$-28.1\,T$		50
	a–3	$-28.1\,T$		50
	3–a	$-24.8\,B$		44
Top Chord	3–5	$-27.8\,B$	-65.7	42
Bottom Chord	1–2	$+10.2\,B$	$+73.0$	14

The very large secondary stresses of 44 per cent to 50 per cent, at joints a and 3 are very significant and show the detrimental effect of the collision strut upon the end post. Without the strut the maximum secondary stresses in this member, given in Table G, Art. 323, are only 7.5 per cent and 9.2 per cent. This case illustrates the general effect of secondary members attached to large primary members in such a

TABLE I.

VALUES OF $\Sigma \delta \angle$, $K \Sigma \delta \angle$, and τ.

Joint. (1)	$\angle$ (2)	$\delta \angle$ (3)	$\Sigma \delta \angle$ (4)	Member. (5)	$K=\frac{I}{l}$ (6)	$K \times \Sigma \delta \angle$ (7)	τ (8)
				13	9.15	.....	+ 16.22
1.....	312	+138.2	+138.2	12	3.80	+ 525.	+154.4
					12.95	+ 525.	
				21	3.80	.....	+ 76.6
2....	123	−249.5	−249.5	23	.255	− 63.6	−172.9
	324	+ 0.57	−249.0	24	3.80	− 948.	−172.4
					7.855	−1011.6	
				35	12.43	.....	− 28.51
	534	−100.0	−100.0	34	1.64	− 164.	−128.5
3....	432	+ 4.95	− 95.0	32	.255	− 24.22	−123.5
	231	+111.3	+ 16.3	31	9.15	+ 149.1	− 12.2
					23.475	− 39.12	

				42	3.80	.....	+ 69.6
4....	243	− 5.52	− 5.52	43	1.64	− 9.05	+ 64.1
	345	−114.4	−119.92	45	2.016	− 241.8	− 50.3
	547	+ 21.68	− 98.24	47	5.96	− 585.5	− 28.7
					13.416	− 836.35	
				56	12.43	.....	−111.7
5....	657	− 37.27	− 37.27	57	.731	− 27.23	−149.0
	754	+ 37.52	+ 0.25	54	2.016	+ 0.50	−111.4
	453	+214.4	+214.65	53	12.43	+2669.	+103.
					27.607	+2642.3	
				68	12.43	.....	−128.5
6....	867	+128.47	+128.47	67	.77	+ 99.0	0
	768	+128.47	+256.94	65	12.43	+3194.	+128.5
				74	5.96	.....	+150.4
	475	− 59.20	− 59.20	75	.73	− 43.2	+ 91.20
7....	576	− 91.20	−150.40	76	.77	− 115.7	0
	678	− 91.20	−241.60	78	.73	− 176.3	− 91.20
	879	− 59.20	−300.80	79	5.96	−1792.	−150.40

way as to cause them to deflect out of line. Other illustrations are given in Art. 342.

327. Effect of Eccentric Joints.—If the axes of the members at any joint do not intersect in a single point, then the primary stresses produce a moment M_n which must be balanced by the secondary bending moments at the joint. This moment, M_n, is taken account of as explained in Art. 308 and eq. (17), by adding to the moment equation of the joint the term $\frac{M_n}{2E}$, or if E is neglected, the term is $\frac{M_n}{2}$. A positive value of this moment is when the tendency of rotation about the joint is clockwise.

Suppose in the Pratt truss of Art. 317, the joints in the top chord and end post are eccentric by 1 inch, the intersection of the axes of the web members being 1 inch below the gravity axis in each case. The secondary stresses in the end post and top-chord members will be determined for the case of a symmetrical loading of 1,000 lbs. at each lower joint. Only five equations will be needed, and the coefficients of τ will be the same as those given in Table D. The absolute terms will be different and will include the moments at the joints due to eccentricity.

The total stresses, S, and the unit stresses, s, are the same as given in Fig. 21. The detailed calculation of the angular changes will not be given, but the results are shown in Table I, together with the values of $\Sigma\ \delta\ \angle$ and $K\ \Sigma\ \delta\ \angle$, as in Art. 319.

The moment of the primary stresses at joint 5 is equal to the horizontal component of the stress in 5–7, multiplied by 1 inch, $= 500 \times \frac{320}{372} \times 1 = 430$, and is negative in sign. The term to be added to the *left* side of the equation is therefore $-430/2 = -215$. The absolute term for joint 5 is then made up as follows, from Column (7), Table I:

Joint 5 (2×2642.3)	+ 5,285
Member 6–5	+ 3,194
" 7–5	− 43
" 4–5	− 242
External moment	− 215
Total	+ 7,979

At joint 3 we may conveniently take the moment centre at the intersection of the diagonal and hip vertical. The moment of the top-chord stress is then − 3,440, and of the end post is + 3,300, giving a net moment of − 140 in.-lbs. The term − 70 is then to be added to the absolute term for the equation for joint 3. At joint 1, assuming the intersection of the axis of 1–2, and the reaction, to be 1 inch below the gravity axis of 1–3, the moment will equal the stress in 1–3 times 1 inch, = − 3,300 in.-lbs., giving the large term − 1,650 to add to the equation for joint 1. The resulting equations are as follows:

$$(1)\quad 25.90\,\tau_1 + 3.80\,\tau_2 + 9.15\,\tau_3 = + 451$$

$$(2)\quad 3.80\,\tau_1 + 15.72\,\tau_2 + .26\,\tau_3 + 3.80\,\tau_4 = + 1{,}522$$

$$(3)\quad 9.15\,\tau_1 + .26\,\tau_2 + 46.96\,\tau_3 + 1.64\,\tau_4 + 12.43\,\tau_5 = - 2{,}448$$

$$(4)\quad 3.80\,\tau_2 + 1.64\,\tau_3 + 26.84\,\tau_4 + 2.02\,\tau_5 + 5.96\,\tau_7 = + 2{,}784$$

$$(5)\quad 12.43\,\tau_3 + 2.02\,\tau_4 + 55.22\,\tau_5 + 12.43\,\tau_6 + .73\,\tau_7 = - 7{,}979$$

Also $\tau_{67} = 0 = \tau_6 + 128.5$

and $\tau_{76} = 0 = \tau_7 - 150.4$.

The solution of these equations results in values of τ as given in Table I. From these values we find fibre stresses and percentage secondary stresses to primary stresses as follows:

TABLE J.

SECONDARY STRESSES WITH ECCENTRICITY.

Member.		Secondary Stress.	Primary Stress.	Percentage Secondary to Primary.	Percentage without Eccentricity.
End Post	13	− 1.16 B	−56.4	2.0	7.5
	31	− 0.47 B		0.8	5.1
Top Chord	35	− 4.15 B	−65.7	6.3	9.2
	53	−10.18 T		15.5	15.2
	56	− 5.45 T	−74.0	7.4	8.8
	65	− 8.34 T		11.2	10.6

In the last column are given the values from Table G, Art. 323, which are the percentages without eccentricity. It will be seen that the effect of eccentricity is small except in the end post, where it happens to be

of such sign to reduce the stresses. Generally speaking, the effect of eccentricity is to increase the secondary stresses.

328. **Effect of Pin-Connections.**—If certain members are pin-connected the maximum moment that can develop at the ends of such members is limited to the moment required to turn the member on the pin. If, on the assumption of rigid joints, the resulting moment is less than this limiting value, then the member will not turn and the moments so calculated are correct. If, however, the calculated moment is greater than such limit, then the member turns and the actual bending moment is equal to the turning moment. Whether a member will turn about the pins depends upon the stiffness of the member, size of pin, and coefficient of friction. A general analysis will assist in judging what is likely to happen.

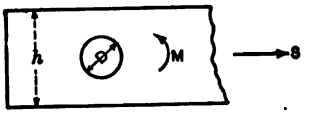

FIG. 22.

Fig. 22 represents the end of a pin-connected member.

Let S = total direct stress;
A = gross sectional area of the body of the member;
s = working stress on gross area;
f = fibre stress due to bending at the joint,
D = diameter of the pin;
k = coefficient of friction;
h = depth of member, assumed as symmetrical;
I = moment of inertia of member;
r = radius of gyration.

Under the stress S, the turning moment required to overcome friction is $M = \frac{S k D}{2} = \frac{s A k D}{2}$. The resulting fibre stress is

$$f = \frac{M h}{2 I} = \frac{s k D h}{4 r^2}, \quad . \quad . \quad . \quad . \quad . \quad (19)$$

whence the ratio of the stress f to the working stress s is

$$f/s = \frac{k D h}{4 r^2}. \quad . \quad . \quad . \quad . \quad . \quad . \quad (20)$$

For rectangular sections, such as eye-bars, $r = .29\,h$, and for built-up sections r will generally range from $.35\,h$ to $.4\,h$. If we take $k = .2$, we then have approximately,

$$f/s = .55\,\frac{D}{h} \text{ to } .30\,\frac{D}{h}. \quad . \quad . \quad . \quad . \quad . \quad (21)$$

For eye-bars D/h is generally not less than $\frac{3}{4}$, whence for such members $f/s = .55 \times .75 = .41$; that is, the secondary stress f must be about 40 per cent of the working stress in order to turn the bar. Such a large secondary stress in the case of narrow sections, as eye-bars, is unusually great and not likely to occur. Even with a coefficient of friction as low as 0.15 the necessary bending moment would not be likely to develop. Hence we may conclude that eye-bars generally do not receive sufficient bending to cause turning on the pins.

In the case of built-up members the ratio of D/h will generally be much smaller than for eye-bars and may indeed be quite small. A ratio of $1/3$ represents an ordinary value. This gives $f/s = \frac{1}{3} \times .30 = .10$ (assuming $r = .4\,h$), that is, a turning on the pins will occur when the secondary stress is 10 per cent of the working stress on *gross* section.

This analysis assumes the pressure on the pin equal to the total stress in the member. For built-up members, continuous beyond the pin, as the usual top chord section, the pin pressure at intermediate joints is only the increment of chord stress and much less than the total stress. In such a case a turning on the pin will be brought about at much lower bending stresses than calculated above. Since a secondary stress of 10 per cent may be considered a minimum, it may be concluded that with a coefficient of friction of $1/5$ to $1/4$, built-up members will, in general, turn upon the pins.

In the calculation of secondary stresses, therefore, in structures partly or wholly pin-connected, it may generally be assumed that eye-bars do not turn and that built-up members will turn. In the latter case a turning moment equal to the moment of friction will develop, which may be taken account of by treating it as an exterior moment at a known value. But for most purposes such moment may be neglected and the pin-ended built-up member omitted in the

calculations, without, however, ignoring the fact that in some cases the friction of turning should be estimated, as for example, at the hinges of an arch.

The value of the coefficient of friction between a pin and its bearing is a matter about which little information is available. It is probable that in new work, with pins well painted, the friction is considerably less than 0.2, but in old work where rusting has taken place the friction is greater. An occasional turning on the pins tends to prevent the friction becoming excessively great through rust, while, on the other hand, a fixed condition of the joint, such as is likely to be the case with eye-bars, tends to increase the resistance to turning by a rusting of the parts. It has often been noted in the removal of old structures that the pins are very firmly fixed in the eye-bar heads, evidently not having turned for many years.

In calculating secondary stresses where some of the members are to be considered free to turn, this condition is conveniently allowed for by simply omitting such member from the equations of moments at the joints. If the member turns, it is equivalent to a member whose moment of inertia is zero, or whose $K = 0$; whence the value of $K \tau$ for the member drops out. In the calculation of the changes of angle, $\delta \alpha$, etc., such members should, however, be considered, the same as others that are rigidly connected.

329. *Top Chord of Pin-Connected Pratt Truss.*—In a pin-connected truss the top chord is generally made continuous and the posts and diagonals pin-connected. In such a case it may be assumed that all members turn at the joints excepting the top-chord sections. At the hip joint the top chord is also generally pin-connected. The calculation of the secondary stresses in the top chord in such a case is a simple problem.

As an example take the Pratt truss analyzed in preceding articles and assume a load of 1,000 lbs. at each lower joint. The top-chord stresses will be calculated, (*a*) with pins concentric and (*b*) with pins eccentric.

(*a*) *Without Eccentricity.*—The values of $\delta \angle$ and of $\Sigma \delta \angle$ are calculated as before, but such calculation need be made for the three upper joints, 3, 5, and 6, only. The necessary values are given in Table K on the following page.

TABLE K.

VALUES OF $\Sigma \delta \angle$, $K \Sigma \delta \angle$, and τ.

Joint. (1)	$\angle$ (2)	$\delta \angle$ (3)	$\Sigma \delta \angle$ (4)	Member. (5)	K (6)	$K \Sigma \delta \angle$ (7)	τ (8)
3....				35	12.43		− 43.0
					12.43		
				56	12.43		−128.8
	657	− 37.27	− 37.27	57	0		
5....	754	+ 37.52	+ 0.25	54	0		
	453	+214.4	+214.65	53	12.43	+2669	+ 85.9
					24.86	+2669	
				68	12.43		−128.5
6....	867	+128.47	+128.47	67	0		
	765	+128.47	+256.94	65	12.43	+3194	+128.5
					24.86	+3194	

At joint 3 the only member considered is 3–5 and the equation is

$$24.86\,\tau_3 + 12.43\,\tau_5 = -2669. \quad . \quad . \quad . \quad . \quad (a)$$

At joint 5, members 5–3 and 5–6 enter, and the equation is

$$49.72\,\tau_5 + 12.43\,\tau_3 + 12.43\,\tau_6 = -8532. \quad . \quad . \quad (b)$$

At joint 6 we have $\tau_{67} = 0$, whence $\tau_6 = -128.5$.

Then from (a) and (b) we derive,

$$\tau_3 = -43.0 \text{ and } \tau_5 = -128.8.$$

The remaining values of τ are calculated in the table in the usual way. The resulting stresses are given in Table L on the following page.

(b) *With Eccentricity.*—Assuming the pins eccentric by 1 inch, the moment of the primary stresses at joint 3 is − 3440, and at joint 5 is − 430. It is zero at 6. Hence the absolute terms of equations (a) and (b) become $-2669 + 1720 = -949$, and $-8532 + 215 = -8317$, respectively. From these we derive $\tau_{35} = +33.6$; $\tau_{53} = +71.1$; $\tau_{56} = -143.6$ and $\tau_{65} = +128.5$. The resulting fibre stresses are given in Table L.

TABLE L.

SECONDARY STRESSES IN PIN-CONNECTED TOP CHORD.

Member.	Without Eccentricity.		With Eccentricity.	
	Secondary Stress.	Percentage of Primary Stress.	Secondary Stress.	Percentage of Primary Stress.
35	0	0	$-12.5\,B$	18.7
53	$-7.4\,T$	11.2	$-10.1\,T$	15.0
56	$-7.4\,T$	10.0	$-9.1\,T$	12.3
65	$-7.4\,T$	10.0	$-6.5\,T$	8.8

330. Effect of Bending Moments in the Members Due to Transverse Loads Applied Between Joints.—Suppose the beam $A\,B$, Fig. 23,

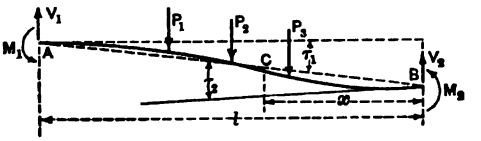

FIG. 23.

to support certain transverse loads, P_1, P_2, etc., and at the same time to be subjected to certain end moments, M_1 and M_2. If the beam were freely supported at A and B, the transverse loads would cause a bending moment at any point C, distant x from B, calculated as for a simple beam. Call this moment M'. The true bending moment in the beam at point C, under the actual conditions, will then be equal to the moment due to M_1 and M_2, plus M', or, from eq. (6), Art. 304,

$$M_x = M_2 - (M_1 + M_2)\frac{x}{l} + M'. \quad . \quad . \quad . \quad (22)$$

The deflection at $B = \Delta = -\int \frac{M\,x\,d\,x}{E\,I}$. Substituting from eq. (22) we derive

$$\Delta = \frac{l^2}{6\,E\,I}(2\,M_1 - M_2) - \int \frac{M'\,x\,d\,x}{E\,I} \quad . \quad . \quad . \quad . \quad (23)$$

and

$$\tau_1 = \Delta/l = \frac{l}{6\,E\,I}(2\,M_1 - M_2) - \frac{1}{E\,I\,l}\int_0^l M'\,x\,d\,x. \quad . \quad (24)$$

Likewise

$$\tau_2 = \frac{l}{6\,EI}(2\,M_2 - M_1) + \frac{1}{EI\,l}\int_0^l M'(l - x)\,dx \quad . \quad (25)$$

in which x is to be measured from B. From these equations we derive the values of M_1 and M_2, as follows:

$$M_1 = \frac{2\,EI}{l}(2\,\tau_1 + \tau_2) - \frac{2}{l^2}\int_0^l M'(l - 3\,x)\,dx \quad . \quad (26)$$

$$M_2 = \frac{2\,EI}{l}(2\,\tau_2 + \tau_1) + \frac{2}{l^2}\int_0^l M'(3\,x - 2\,l)\,dx. \quad . \quad (27)$$

In these equations the quantity M' is the bending moment in a simply supported beam due to the given external loads; its sign is to be considered as positive when it tends to cause bending in the same sense as the moment M_2, such as would be caused by loads acting *downward* in Fig. 23.

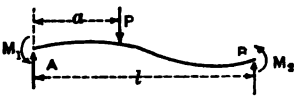

FIG. 24.

For a single load, P, applied a distance a from A (Fig. 24), the values of the terms involving M' in eqs. (26) and (27) reduce to $-P\frac{a(l-a)^2}{l^2}$ and $-P\frac{a^2(l-a)}{l^2}$, respectively. From Art. 6 we note that these values are the same as the end moments of a beam fixed at the ends. Therefore we may write in general

$$M_1 = \frac{2\,EI}{l}(2\,\tau_1 + \tau_2) - M_1^f \quad . \quad . \quad . \quad . \quad (28)$$

and

$$M_2 = \frac{2\,EI}{l}(2\,\tau_2 + \tau_1) + M_2^f. \quad . \quad . \quad . \quad . \quad (29)$$

where M_1^f and M_2^f are the end moments in a beam of fixed ends and loaded with the given transverse loads. The signs of these moments are to be taken as positive when causing compression in the upper fibres. For loads acting downward they will be negative. The general equation for fibre stress is

$$f = 2\,(2\,\tau_{nm} + \tau_{mn})\frac{c}{l} - M^f_{nm} \times \frac{c}{I}. \quad . \quad . \quad . \quad (30)$$

In applying these equations to a problem of secondary stresses the quantities M^f are to be calculated separately. Then in place of eq. (16), Art. 308, we have

$$2\,(K_{n1}\,\tau_{n1} + K_{n2}\,\tau_{n2} + \text{etc.}) + K_{1n}\,\tau_{1n} + K_{2n}\,\tau_{2n} + \text{etc.} - \frac{M^f_{n1}}{2\,E} - \frac{M^f_{n2}}{2\,E} - \text{etc.} = 0 \quad . \quad . \quad . \quad . \quad . \quad (31)$$

there being terms $\frac{M^f}{2\,E}$ for each member at the joint which is subjected to transverse forces.

331. Secondary Stresses in Top Chord Due to Weight of Member.—As an illustration of the application of the preceding article the stresses in the top chord of the truss previously analyzed will be determined so as to include the effect of its own weight. In this case it will be desirable to assume a joint load corresponding to the actual load on the structure. A joint load of 75,000 lbs. will, therefore, be taken, applied at each lower joint. The top chord will be assumed as pin-connected, as in Art. 329, and equations written out for joints 3 and 5.

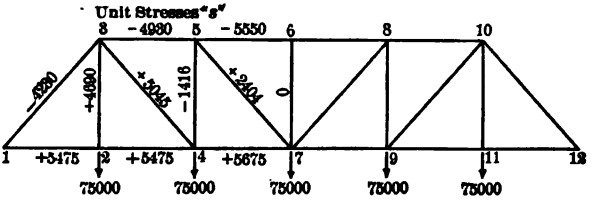

FIG. 25.

(*a*) *Without Eccentricity.*—Fig. 25 gives the unit stresses, s, and Table M, the values of $\Sigma\,\delta\,\angle$, etc.

The end moments of members 3–5 and 5–6, due to their own weight, must be determined, on the assumption of fixed ends. This moment is $-\frac{1}{12}\,w\,l^2$, where w is the load per unit length. Taking the weight of 3–5 and 5–6 at 178 lbs. per foot, the moment at each end is $-$ 126,600 in.-lbs. Therefore, in the equation for joint 3, the quantity $+\frac{126{,}600}{2}$ is to be added to the absolute term, and for joint 5 nothing

TABLE M.

TOP CHORD, WEIGHT INCLUDED.

Values of $\Sigma\,\delta\angle$, $K\,\Sigma\,\delta\angle$, and τ.

Joint. (1)	$\angle$ (2)	$\delta\angle$ (3)	$\Sigma\,\delta\angle$ (4)	Member. (5)	K (6)	$K\,\Sigma\,\delta\angle$ (7)	τ (8)
3				35	12.43	.....	−6140
					12.43		
				56	12.43	.....	−8920
5	657	− 2795	− 2795	57	0		
	754	+ 2815	+ 20	54	0		
	453	+16090	+16110	53	12.43	+200,000	+7190
					24.86	+200,000	
				68	12.43	.....	−9635
6	867	+9635	+ 9635	67	0		
	765	+9635	+19270	65	12.43	+239,600	+9635
					24.86	+239,600	

is added, as the values of M' for the two members 5–6 and 5–3 are equal but of opposite signs.

The resulting equations are

$$24.86\,\tau_3 + 12.43\,\tau_5 = -263{,}300$$
$$12.43\,\tau_3 + 49.72\,\tau_5 + 12.43\,\tau_6 = -639{,}600.$$

Then as before, $\tau_{67} = 0$, and $\tau_6 = -9{,}635$. The resulting values of τ are given in Table M.

Having the values of τ the fibre stresses at the joints are calculated by means of eq. (30). This requires the term $-M' \times \frac{c}{I}$ to be added to the stress as previously calculated. The results are given in Table N.

The effect of the weight of the member is to reduce the secondary stresses at the joints. This is due to the fact that, with pin-connections, the only secondary stresses arising from rigidity of joints in the top chord are due to the bending of the chord as a whole into a slight curve

TABLE N.

SECONDARY STRESSES IN TOP CHORD, INCLUDING EFFECT OF WEIGHT OF MEMBER.

Member.	Without Eccentricity.		With Eccentricity.	
	Secondary Stress.	Percentage of Primary Stress.	Secondary Stress.	Percentage of Primary Stress.
35	0		$-938\ B$	19.0
53	$-180\ T$	3.7	$-382\ T$	7.8
56	$-180\ T$	3.2	$-309\ T$	5.6
65	$-300\ T$	5.4	$-237\ T$	4.2

corresponding to the deflection of the entire structure. This produces small compressive stresses in the upper fibres throughout, as shown in Art. 329, Table L. When the effect of the weight of the members is added, this reduces the stresses at the joint but increases those at the centres of the members.

At the centres of the members the stresses may be found as follows: Consider member 5–6. The moment at the centre of a fixed beam being $\frac{1}{24} w l^2$, and at the ends $-\frac{1}{12} w l^2$, the centre moment exceeds the end moment by $\frac{1}{8} w l^2$, which is the centre moment in a simple beam. In the present example, this moment is $3/2 \times 126{,}600 = +189{,}900$ in.-lbs., giving a fibre stress in the top fibres of -438 lbs. per sq. in. From Table M, the stress at one end is -180 and at the other end is -300, hence at the centre it will be $\frac{-180-300}{2} - 438 = -678$ lbs. per sq. in., or 11 per cent of the primary stress. Fig. 26 (*a*) shows the variation in upper fibre stress throughout.

(*b*) *With Eccentricity.*—The results obtained with an eccentricity of 1 inch are given in Table N. Eccentric pins in this case have little effect except at joint 3. Fig. 26 (*b*) shows the fibres stresses in this case.

332. Secondary Stresses Due to Fixed Supports.—If no hinge is provided at the support, as is quite common in the case of small trusses, and as sometimes occurs in other cases, the joint in question will be

restrained and the secondary stresses will generally be much increased thereby. In calculating the secondary stresses where any given joint is thus restrained the equation for the joint in question must include an external moment, due to the action of the support. This moment is un-

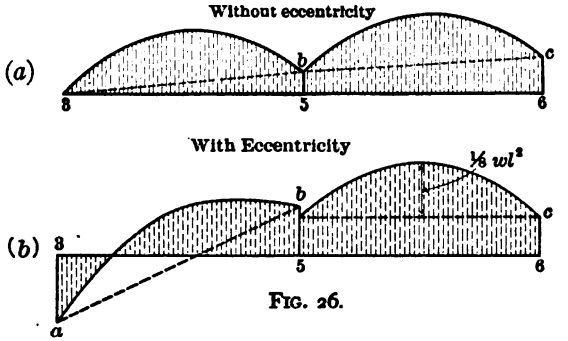

FIG. 26.

known, but the deflection angle of the joint is fixed and may be calculated by other means, thus leaving the external moment as the unknown quantity in the equation for the joint, in place of the deflection angle.

Thus in Fig. 27, suppose joint 1 be fixed by the support, thus developing an external moment equal to M_1. The value of $\delta \angle$ for

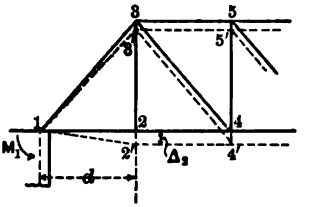

FIG. 27.

angle 312 is calculated as usual. The deflection angle of 1–3 is τ_{13}, the reference angle of the joint, and that of 1–2 is $\tau_{13} + \delta\,(312)$. The deflection angle of 1–2 is now to be directly determined by calculating the deflection of joint 2 by the usual formula $\Delta = \Sigma \frac{Sul}{EA}$. If this deflection is Δ_2 then the deflection angle $\tau_{12} = \Delta_2/d^1$. This angle then becomes known and thence the reference angle τ_{13} or τ_1. The equation of the joint is

$$2\,(K_{13}\,\tau_{13} + K_{12}\,\tau_{12}) + K_{31}\,\tau_{31} + K_{21}\,\tau_{21} - \frac{M_1}{2\,E} = 0. \quad . \quad (37)$$

Written out in the usual manner, this equation will involve τ_1, τ_2, τ_3, and M_1, but, as shown above, τ_1 is known, hence the unknowns are τ_2, τ_3, and M_1. The unknowns are thus the same in number as in the usual case and are readily determined in the solution of the equations for the entire structure. Unless especially desired, the value of M_1 need not be determined, as τ_1 is known from the deflection of joint 2. In this case, after determining τ_1, we proceed at once to the equations for joints 2 and 3, in which τ_1 will appear as a known quantity.

If E is to be generally omitted in the calculations it should also be omitted in the calculation of Δ_2, giving $\Delta_2 = \Sigma \frac{Sul}{A}$.

EXAMPLE.—Suppose the Pratt truss of Art. 317 be supported by a fixed shoe so that no turning can take place at this joint. The resulting secondary stresses for a load of 1,000 lbs. at each joint will be approximately determined by considering only joints 1, 2, and 3.

The first step is to calculate the deflection of joint 2 for the given load by the formula $\Sigma \frac{Sul}{A}$. The result is 159,300 units. The deflection angle τ_{12} is therefore $159{,}300/320 = +498$. Calculation of the values of $\Sigma \delta \angle$ and $K \Sigma \delta \angle$ are given in Table O.

From the table we have $\tau_{12} = \tau_1 + 138.2$. But $\tau_{12} = 498$, hence $\tau_1 = 498 - 138 = +360$. The equations for joints 2 and 3 are

$$15.7\,\tau_2 + 3.80\,\tau_1 + .26\,\tau_3 = +1522.$$
$$.26\,\tau_2 + 9.15\,\tau_1 + 46.96\,\tau_3 = +141.8.$$

Substituting the value of $\tau_1 = 360$, we derive $\tau_2 = +11.04$, $\tau_3 = -67.2$, and thence the values of τ given in the table. The moments at joint 1 are:

$$M_{12} = 2K_{12}(2\tau_{12} + \tau_{21}) = +7{,}480 \text{ in.-lbs.},$$
$$M_{13} = 2K_{13}(2\tau_{13} + \tau_{31}) = +12{,}240 \text{ in.-lbs.}$$

For equilibrium of the joint the external moment furnished by the support must be equal to $-(M_{12} + M_{13}) = -19{,}720$ in.-lbs. The minus sign signifies a left-handed moment.

The fibre stresses in the members 1–2 and 1–3 are 57.4 and 38.4, or 79 per cent, and 68 per cent, respectively, of the primary stresses. These large values show the importance of hinged bearings at the supports, and in connection with the discussion of Art. 328 indicate that there must be some turning upon the pins under these conditions.

The effect of a fixed shoe upon the pressure on the masonry may be noted. The negative moment developed at the support is 19,720 in.-lbs. The reaction is 2,500 lbs. This result, therefore, gives an eccentricity of bearing of $\frac{19{,}720}{2{,}500} = 7.9$ inches.

TABLE O.

EFFECT OF FIXED SUPPORT.

Values of $\Sigma \delta \angle$, $K \Sigma \delta \angle$, and τ.

Joint. (1)	$\angle$ (2)	$\delta \angle$ (3)	$\Sigma \delta \angle$ (4)	Member. (5)	K (6)	$K \Sigma \delta \angle$ (7)	τ (8)
				13	9.15	.....	+360
1	312	+138.2	+ 13.82	12	3.80	+ 525	+498
					12.95	+ 525	
				21	3.80	.....	+ 11.0
2....	123	−249.5	−249.5	23	.26	− 63.6	−238.5
	324	+ 0.6	−248.9	24	3.80	− 948.	−238.0
					7.86	−1011.6	
				35	12.43	.....	− 67.2
	534	−100.0	−100.0	34	1.64	− 164.0	−167.2
3....	432	+ 4.9	− 95.0	32	.26	− 24.2	−162.2
	231	+111.3	+ 16.3	31	9.15	+ 149.1	− 50.9
					23.48	− 39.1	

In certain cases the stresses which would be produced by rigid bearings would be much greater than in this example. In a cantilever bridge, for example, the normal changes of angle at the main pier *B*, Fig. 28, is unusually great, as the deformations of both arms of the

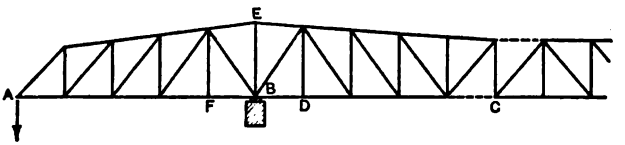

FIG. 28.

cantilever contribute to this change when the span *B C* is loaded. In calculating the stresses in this case, the change of angle at *B* is first determined by calculating the deflection of joint *D*, as in the example given above. This determines the deflection angles at *B*. The equations are then written out for a sufficient number of joints surrounding joint *B* to secure the desired accuracy.

333. Calculation of Changes of Angles, $\delta\alpha$, etc., in Figures of Four or More Sides.—The method of calculation of the changes of angle, $\delta\alpha$, etc., at a joint, explained in Art. 303, relates to triangular figures. Frequently a case will arise where the space formed by contiguous members of the truss is of four or even five sides, as occurs in a double intersection truss, or one in which sub-panels are employed.

In such a case the simplest method of procedure is to assume additional members inserted so as to divide the space into triangles, and then to calculate the deformation of such imaginary members by calculating the relative deflection of the two joints which they connect, assuming the sectional areas of the inserted members to be zero. The changes of angles can then be calculated in the usual way for the several triangles, and two or more values added together, where necessary, to get the total change of angle between two of the real members of the truss.

Two common examples of this problem will be given and general formulas derived which may be used to expedite the calculations.

334. *The Baltimore Truss with Sub-ties.*—Fig. 29 represents any panel of a Baltimore truss. The member $m\,O$ is not supposed to be present. The figure $M\,O\,o\,m$ is therefore a quadrilateral, and the problem is to calculate the changes of angles of this figure. To do this, suppose a member $m\,O$, of zero cross section, to be inserted. Calculate now the deflection of O with respect to m, due to the actual stresses in the several members of the panel, which stresses are supposed to be already known. Suppose this deflection is Δ_8. Then $\Delta_8 \div \frac{c}{2}$ is the unit deformation of the length $m\,O$. This quantity may then be used as s_8, exactly as if $m\,O$ were a member of the truss having this deformation, and the angular changes of the triangles A and B determined in the usual way.

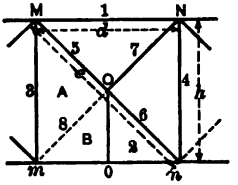

FIG. 29.

To express the result algebraically let s_1, s_2, s_3, etc., be the unit stresses in the several members of the panel, numbered as shown. Then the calculation of the deflection of O with respect to m is as follows:

Member.	Length.	u	S/A	$\frac{S u l}{A}$
1	d	$-d/c$	s_1	$-s_1\frac{d^2}{c}$
2	d	$-d/c$	s_2	$-s_2\frac{d^2}{c}$
3	h	$-h/c$	s_3	$-s_3\frac{h^2}{c}$
4	h	$-h/c$	s_4	$-s_4\frac{h^2}{c}$
5	$c/2$	$+1$	s_5	$s_5\frac{c}{2}$
6	$c/2$	$+1$	s_6	$s_6\frac{c}{2}$
7	$c/2$	$+1$	s_7	$s_7\frac{c}{2}$

The deflection is (omitting E)

$$\Delta_8 = \Sigma \frac{S u l}{A} = -(s_1 + s_2)\frac{d^2}{c} - (s_3 + s_4)\frac{h^2}{c} + (s_5 + s_6 + s_7)\frac{c}{2}. \quad (33)$$

The corresponding unit strain in $m\,O$, due to this deformation may be called s_8, and will be equal to $-\Delta_8 \div \frac{c}{2}$. Therefore we have

$$s_8 = 2(s_1 + s_2)\frac{d^2}{c^2} + 2(s_3 + s_4)\frac{h^2}{c^2} - (s_5 + s_6 + s_7). \quad (34)$$

This quantity s_8 is to be used just as if $m\,O$ were a real member of the truss.

The changes of angles at m and O, of the triangles A and B having been determined, the changes in the real angles $M\,m\,o$ and $M\,O\,o$ are determined by addition, and the member $m\,O$ is then omitted in the equations for joints m and O.

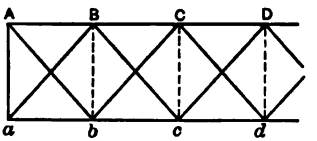

FIG. 30.

335. *The Double Triangular Truss.*— In the double triangular truss, Fig. 30, the calculations of the changes of angles is readily accomplished after determining the changes of length of the lines $B\,b$, $C\,c$, etc.

Beginning at the end panel, the deflection of B, relative to b, is determined as in Art. 334. With a notation similar to that used before, the calculations are as follows (Fig. 31):

Member.	Length.	u	$\frac{S}{A}$	$\frac{S\,u\,l}{A}$
1	d	d/h	s_1	$s_1 \frac{d^2}{h}$
2	d	d/h	s_2	$s_2 \frac{d^2}{h}$
3	h	$+1$	s_3	$s_3 h$
4	h	$-c/h$	s_4	$-s_4 \frac{c^2}{h}$
5	c	$-c/h$	s_5	$-s_5 \frac{c^2}{h}$

The unit deformation of $B\,b$ is

$$s_6 = -(s_1 + s_2)\frac{d^2}{h^2} + (s_4 + s_5)\frac{c^2}{h^2} - s_3. \quad . \quad . \quad . \quad (35)$$

Having found s_6 for $B\,b$, then the deformation of $C\,c$ is found in a similar way by considering the quadrilateral $B\,C\,b\,c$, and so on.

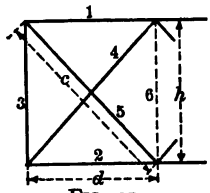

FIG. 31.

The unit deformations in the several verticals being known, the changes of angles at the several joints are found as usual from the triangles $a\,B\,b$, $B\,b\,C$, etc.

336. Relative Amounts of Secondary Stresses in Trusses of Different Types.—The examples of the preceding articles serve to give some notion of the amount of secondary stress likely to exist in the ordinary Pratt truss. However, as this stress will vary greatly with the proportions of the structure, no single set of values can be applied generally. If close results are desired they must be worked out for the particular truss at hand.

Owing to the somewhat lengthy calculations involved, it is probable that secondary stresses will not as a rule be determined for each individual case, except in large and important structures; and that the allowance necessary to be made for such stresses will be based on results obtained on typical designs similar to the structures in question. Calculations of such typical structures will not only serve to show the amount necessary to allow for secondary stresses, but will give valuable information regarding the relative merits of different designs so far as this feature is concerned. In such calculations the information needed is generally the ratio of secondary stress to primary stress, when

the latter is a maximum, as the total is then usually a maximum. Where the secondary stresses are very high, however, it may happen that the maximum total is dependent more upon the secondary than upon the primary stress. Such cases require special consideration.

It is not the purpose of this work to give the analysis of a large number of particular trusses. Such analyses can readily be made in any office, and of such structures as may be most important for the office concerned. A little familiarity with the method will enable any good computor to make a complete analysis of an ordinary truss in two or three working days, or less. It is thought, however, that a study may profitably be made here of types of trusses and proportions, by the use of certain approximate methods, making general assumptions as to relative sections and unit stresses. In this way it is proposed to study five of the most common types of trusses: (1) The Pratt system; (2) the Warren system without verticals; (3) the Warren system with verticals; (4) the double Warren system without verticals; and (5) the double Warren system with verticals.

337. *General Method of Analysis.*—In the method of investigation here used it will be assumed that the truss is of uniform construction for several panels, that is, that all of several consecutive panels are exactly alike. It will also be assumed that the unit stresses are, likewise, the same in these several panels, so that both the primary and the secondary stresses will be the same in the different panels. Then, by assuming various proportions for panel length, sectional areas, and unit stresses, the general effect of a variation in these elements can be seen and some notion obtained of the relative merits of various types of trusses.

338. *The Pratt Truss System.*—The Pratt system will be investigated by applying this method of analysis to a number of trusses in which the ratio of height to panel length, the relative moments of inertia, and the relative primary stresses in the various members will be varied. To illustrate the method of analysis, detailed calculations will be made of one case, with three different assumptions as to primary stresses. The results of this analysis together with several other cases are tabulated in Table Q.

A truss will be assumed whose ratio of height to panel length is 4 : 3, Fig. 32. The moment of inertia of all the web members will be

assumed to be equal and that of the chords to be four times that of the webs, the same for top and bottom chords. The absolute values of l and I need not be known in getting the values of τ for the various members; only relative values are required (assuming joints to be concentric). We may then, for brevity, let $l_{24} = 3$; $l_{34} = 4$, and

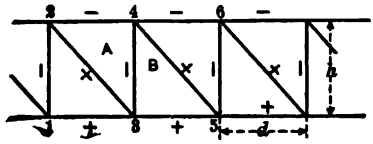

FIG. 32.

$l_{23} = 5$. Also $I_{24} = I_{13} = 4$, and $I_{23} = I_{34} = 1$. As to unit stresses, three conditions will be assumed:

(a) stress in chords = 10, stress in webs = 10;
(b) stress in chords = 5, stress in webs = 10;
(c) stress in chords = 10, stress in webs = 0.

Positive moment and positive shear are assumed, giving compression in the upper chord and verticals, and tension in the lower chord and diagonals.

Case (a), assuming equal stresses in chords and webs, corresponds to a condition of loading which produces about equal stresses in these members, as for example, at sections near the end of a simple span; case (b), with one-half as much stress in chords as webs, corresponds to a section of truss or a loading such that the shear is a maximum, but the moment is about one-half the maximum, as might occur in sections near the centre of a simple span under partial load; and case (c), with zero stress in the webs, corresponds to a condition of maximum moment and zero shear. These conditions will fairly represent the range necessary for a good knowledge of the relations of secondary and primary stresses, not only for ordinary simple trusses, but for such structures as stiffening trusses of suspension bridges and the like. The results thus obtained are particularly applicable to long trusses of numerous panels.

In the calculation of the secondary stresses, under the assumed conditions, it will be necessary to consider two joints only, such as joints 3 and 4, since $\tau_2 = \tau_4 = \tau_6$ and $\tau_1 = \tau_3 = \tau_5$.

TABLE P.

GENERAL CASE OF PRATT SYSTEM.

Values of $\Sigma \delta \angle$ and $K \Sigma \delta \angle$.

Joint.	Member.	K	$\angle$	Case (a).			Case (b)			Case (c).		
				$\delta \angle$	$\Sigma \delta \angle$	$K \Sigma \delta \angle$	$\delta \angle$	$\Sigma \delta \angle$	$K \Sigma \delta \angle$	$\delta \angle$	$\Sigma \delta \angle$	$K \Sigma \delta \angle$
3	31	1.33	.....	.....	.....	.....	.....	.....	.....	.....	.....	.....
	32	.20	132	−26.7	−26.7	− 5.33	−26.7	−26.7	− 5.33	0	0	0
	34	.25	234	− 15.0	−41.7	−10.42	−11.2	−37.9	− 9.48	−7.5	− 7.5	− 1.87
	35	1.33	435	+26.7	− 15.0	−20.00	+30.4	− 7.5	−10.00	−7.5	−15.0	−20.00
		3.11				−35.75			−24.81			−21.87
4	46	1.33	.....	.....	.....	.....	.....	.....	.....	.....	.....	.....
	45	.20	645	−26.7	−26.7	− 5.33	−26.7	−26.7	− 5.33	0	0	0
	43	.25	543	0	−26.7	− 6.67	− 3.7	−30.4	− 7.60	+7.5	+ 7.5	+ 1.87
	42	1.33	342	+41.7	+ 15.0	+20.00	+37.9	+ 7.5	+10.00	+7.5	+15.0	+20.00
		3.11				+ 8.00			+ 2.93			+21.87

The changes in angle at joints 3 and 4 are found from a consideration of triangles A and B, in the same manner as explained in previous examples. These values, and the calculation of $K \Sigma \delta \angle$ for the three cases, (a), (b), and (c), are given in Table P.

In formulating the equations for joints 3 and 4, note that $\tau_{13} = \tau_{35}$, $\tau_{31} = \tau_{53}$, $\tau_{23} = \tau_{45}$, etc.; and $\tau_1 = \tau_3 = \tau_5$; $\tau_2 = \tau_4 = \tau_6$. The resulting equations for the two joints are as follows, for all three cases

	(a)	(b)	(c)
$8.88\,\tau_3 + .45\,\tau_4 =$	+ 103.5	+ 72.5	+ 61.9
$.45\,\tau_3 + 8.88\,\tau_4 =$	− 20.2	+ 10.7	− 61.9

Solving we have

	(a)	(b)	(c)
$\tau_3 =$	+ 11.80	+ 8.13	+ 7.34
$\tau_4 =$	− 2.88	+ 0.79	− 7.34

From these values the several values of τ are calculated, from which the bending moments may be determined. For present purposes, however, it will be more useful to calculate the quantity $2\,(2\,\tau_{nm} + \tau_{mn})$, which, after multiplying by c/l, will be the fibre stress. Since, however, the ratio of c/l has not been assumed, the calculations will not be carried further. For convenience we may call the quantity $2\,(2\,\tau_{nm} + \tau_{mn})$, the *coefficient* of secondary stress. This coefficient, for the three cases above considered, is given in Table Q, with other values for other assumed proportions. Each member will have a separate coefficient for each end, but the larger of the two values only is given in the table.

Coefficients of Secondary Stress for Pratt Trusses of Various Proportions. Following the methods illustrated in the preceding article, twenty cases have been investigated and the results tabulated in Table Q. Two different ratios of height to panel length have been assumed. In part of the trusses the values of I for the two chords have been taken to be the same, and in part the value of I for the lower, or tension chord, has been taken at one-half that of the upper chord. The value of I for the webs has been taken at one-quarter and one-half that of the upper chord. Three relations of stress intensity have also been taken. The results are given as "Coefficients of Secondary Stress" in the last four columns of the table. As explained above, these co-

efficients, when multiplied by the value of c/l for any member, will be the secondary fibre stress. Its relation to the primary stress is readily determined by referring to the assumed values of the latter in Cols. (5) and (6).

An examination of these coefficients brings out clearly several general relations. In the first place it is seen that the maximum secondary stresses occur when both the chords and the webs are fully stressed.

The secondary stresses for maximum chord stress and minimum web stress are very small.

Comparing with respect to size of web members it is seen that as the web members increase in size their stress decreases and that in the chords increases. It must be remembered, however, that the values given in the table are to be multiplied by c/l to get actual fibre stress, so that with slender web members the high values of the coefficients may not mean very high fibre stress.

Comparing with respect to relative size of the two chords, when these are equal the coefficients are about equal, but a decrease in size of the lower chord increases considerably its coefficient.

Comparing on the basis of panel length, the ratio of 4:4 gives a smaller coefficient for web members than the 4:3 ratio, but somewhat larger for the chords. For the same height of truss and same width of members the ratio c/l for the chords will be three-fourths as great for the 4:4 panel as for the 4:3 panel. Taking this into account, the fibre stresses in the chords of the 4:4 panel, under full load, will be about 80 per cent as large as in the 4:3 panel. In the webs they are from 70 to 75 per cent as large.

Again, since the coefficients hold good no matter what the actual values of c/l may be, so long as the assumed proportions between the members are maintained, it follows that the secondary stresses are directly proportional to the widths of the members and inversely proportional to their lengths.

For compression members the value of c/l will usually range from about $\frac{1}{30}$ to $\frac{1}{80}$, corresponding to values of l/r of from 40 to 100. A value of $\frac{1}{40}$ applied to the chord coefficient gives secondary stresses

TABLE Q.

SECONDARY STRESSES IN PRATT TRUSSES. (FIG. 32.)

Ratio of Height to Panel Length. $h:d$	Moments of Inertia.			Primary Stress Intensity.		Coefficients of Secondary Stress.			
	Top Chord.	Bot. Chord.	Webs.	Chords.	Webs.	Top Chord.	Bottom Chord.	Vertical.	Diagonal.
(1)	(2)	(3)	(4)	(5)	(6)	(7)	(8)	(9)	(10)
				10	10	43	41	178	148
	4	4	1	5	10	35	34	178	141
				10	0	16	14	0.3	15
				10	10	63	60	159	127
	4	4	2	5	10	55	53	158	120
				10	0	17	17	0.7	14
				10	10	93	86	132	99
4 : 3	4	4	4	5	10	84	80	131	92
				10	0	19	19	1	14
				10	10	41	62	171	141
	4	2	1	5	10	34	56	171	134
				10	0	16	17	0	15
				10	10	61	92	150	119
	4	2	2	5	10	40	73	157	119
				10	0	17	18	1	15
	4	4	1	10	10	49	46	153	112
	4	4	2	10	10	70	64	134	92
4 : 4	4	4	4	10	10	97	86	110	67
	4	2	1	10	10	48	66	146	106
	4	2	2	10	10	64	91	125	85

varying from 15 per cent to about 22 per cent of the primary stress when the latter is a maximum; and applying a ratio of $\frac{1}{60}$ to the webs gives values of 20 per cent to 30 per cent of the maximum primary. These values are significant of the amount of secondary stress due to general truss action and which cannot be avoided. Local effects due to the deformation of hangers and other secondary members may easily add 100 per cent to the general values here given.

339. *The Warren Truss System.*—Calculations similar to those above given for the Pratt truss have been made for the Warren truss

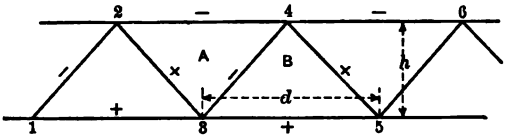

FIG. 33.

system, both with and without verticals. The results are given in Table R. Proportions and unit stresses have been varied as shown in the table. Where verticals are used their moment of inertia has been taken at $\frac{1}{20}$th of the top chord. The actual ratio may be considerably less than this, but even at this value the bending resistance of these members has but very little effect upon the stresses in the main mem-

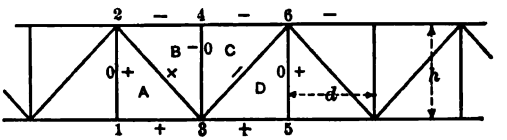

FIG. 34.

bers. The stresses in the verticals themselves are dependent mainly upon the ratio of their width to length.

Both tension and compression verticals are assumed to exist, but only one set is assumed to be stressed in any particular case, the other set being used merely to support the opposite chord.

Here, as in the case of the Pratt truss, it is seen that the maximum secondary stresses occur when both chords and webs are fully stressed.

TABLE R.

SECONDARY STRESSES IN WARREN TRUSSES. (FIGS. 33, 34.)

Ratio of Height to Panel Length. $h:d$	MOMENTS OF INERTIA.			PRIMARY STRESS INTENSITY.		COEFFICIENTS OF SECONDARY STRESS.		
	Top Chord.	Bottom Chord.	Webs.	Chords.	Webs.	Top Chord.	Bottom Chord.	Webs.
(1)	(2)	(3)	(4)	(5)	(6)	(7)	(8)	(9)
4 : 6	4	4	1	10	10	48	48	76
				5	10	33	33	69
	4	4	2	10	10	60	60	65
				5	10	45	45	57
	4	2	1	10	10	47	62	73
				5	10	32	47	65
	4	2	2	10	10	56	77	62
				5	10	42	62	53
4 : 4	4	4	1	10	10	42	42	108
	4	4	2	10	10	57	57	93
	4	2	1	10	10	41	59	103
	4	2	2	10	10	54	81	87

With Verticals.

			Diag.	Vertical.	Chords.	Diagonals.	Verticals.			Diagonals.	Verticals.
4 : 3	4	4	1	0.2	10	10	+10	26	96	75	124
	4	4	2	0.2	10	10	+10	32	101	65	124
	4	2	1	0.2	10	10	+10	26	100	71	125
				0.2	10	10	−10	97	34	71	125
	4	2	2	0.2	10	10	+10	30	100	60	127
				0.2	10	10	−10	97	42	60	127

Comparing the Warren system with the Pratt, for ratio of $h : d = 4 : 6$ in the former and $4 : 3$ in the latter case, it is to be noted that the secondary stresses in the chords are very nearly the same, but in the webs they are much smaller in the Warren system. Comparing the trusses of shorter panel-lengths (ratio $h : d = 4 : 4$), with the longer panel-length (ratio $h : d = 4 : 6$), about the same differences are to be seen as in the Pratt system. The shorter panel has somewhat smaller values for the "coefficient," but when these are multiplied by c/l the fibre stresses will be considerably greater.

The results obtained for the trusses with verticals are very instructive. Where the primary stress in the vertical is plus, the structure is a through bridge, the verticals being in tension; and when this stress is minus the structure is a deck bridge. The effect of the strains in the verticals upon the chords is seen to be very great. The coefficients for the lower chords in the through bridges and those of the upper chord in the deck bridges are all about 100, while for the opposite chord they range from 26 to 42, which are very small values. To secure small secondary stresses in such trusses the sectional areas of the verticals, where supporting joint loads, should therefore be made large.

The stresses in the diagonals are about the same as in the truss without verticals. The coefficients for the verticals are large, but as these are generally narrow members the fibre stresses are not high.

It is to be noted from the result of both Tables Q and R that the larger and stiffer members tend to control the flexure at the joint. A reduction of moment of inertia of any member tends to increase the deflection of that member and reduce that of others. To maintain a balance in the fibre stresses themselves it is necessary to make the width of a member correspond in a measure with its moment of inertia. Wide members of small moment of inertia (thin or unsymmetrical sections, as, for example, a T-section composed of a plate and two angles) are likely to have high secondary stresses; narrow and compact members will have low secondary stresses. This statement does not, of course, take account of the long column action in compression members, the effects of which tend in the opposite direction.

340. *The Double Intersection Triangular Truss.*—In a multiple intersection truss the independent action of the different web systems

may give rise to very severe secondary stresses, especially in the chord members. If one system happens to be loaded considerably heavier than the other for several panels, the joints of the more heavily loaded system will all deflect more than the others and will bend the chords accordingly, producing large secondary stresses. The amount of such action depends upon the amount of the excess load on the one system and this depends, in any case, upon the actual wheel concentrations. If the panel-length corresponds to a half-car length (18 to 20 feet), the conditions are very unfavorable, as a train of heavy cars would give a large excess on the one system throughout the entire structure. A panel-length equal to one-half the length of a locomotive would also give a heavy excess in the case of double-header operation. An exact solution for any given structure and loading can be made by the use of influence lines, but a general analysis of some value may be obtained by assuming a certain percentage of excess on the one system over that on the other.

Consider the truss of Fig. 35 and assume that the load on the full system is 25 per cent greater on the average than that upon the dotted

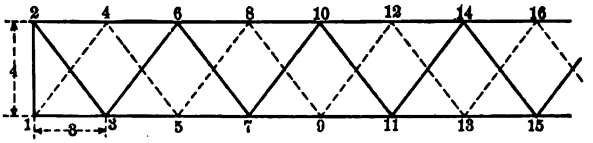

FIG. 35.

system. In view of the very heavy concentrations in use, and the possibility of correspondence of panel length and wheel spacing, such excess is not at all unlikely to occur. The maximum effect produced will be near the centre of the structure where the deflections are a maximum. We will consider a section at joint 13, six panels from the left end, and assume that the joints 3, 7, 11, etc., of the full system are loaded with 25 per cent greater load than the joints 5, 9, 13, etc., of the dotted system. It will also be assumed that the average stress intensity in the chords is 10, that in the webs of the full system is 7.5, and that in the dotted system is 6. We may then proceed to determine the unit deformations along the vertical lines 11–12, 13–14, and 15–16, as explained in Art. 335, eq. (35). In this problem the values of s_1 and s_2 of that

equation are equal and of opposite sign, and therefore the term $(s_1 + s_2) \times \frac{d^2}{h^2}$ disappears. We also have $s_4 + s_5 = \pm 1.5$ in all cases. The stress in 1–2 may be taken at -7.5. Then assuming $c^2 = 1.6\,h^2$ approximately, we have, for the deformation of the vertical 3–4,

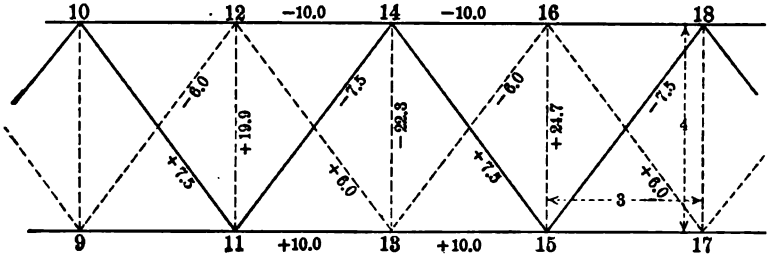

FIG. 36.

$s = +7.5 + 2.4 = +9.9$; then for the vertical 5–6, $s = -9.9 - 2.4 = -12.3$, etc. Finally we have for

$$11\text{–}12,\ s = +7.5 + 5 \times 2.4 = +19.9$$
$$13\text{–}14,\ s = -7.5 - 6 \times 2.4 = -22.3$$
$$15\text{–}16,\ s = +7.5 + 7 \times 2.4 = +24.7$$

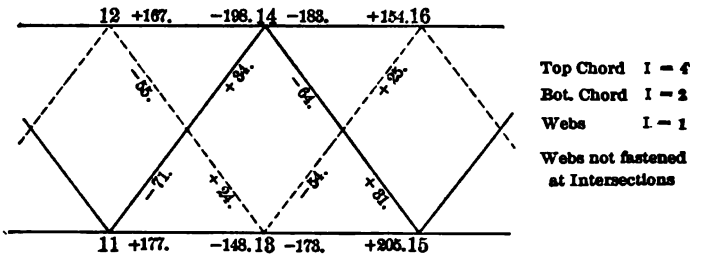

FIG. 37.

The unit strains in all members will therefore be as shown in Fig. 36. It will be assumed, as approximately correct, that the deformations and stresses at joint 12 are the same as at joint 16, those at 11 the same as at 15, etc. Hence in the analysis it will be necessary to write out equations for joints 11, 12, 13, and 14.

Two general cases have been considered: first, with the diagonals not connected at their intersections; and second, with those members

rigidly riveted together. In the latter case it is necessary to write out two additional equations for the two interior joints. The results of these calculations are given in Figs. 37, 38, and 39. The trusses of Figs. 37 and 38 differ only in the relative size of the web members; in both cases the webs are not connected at their intersections.

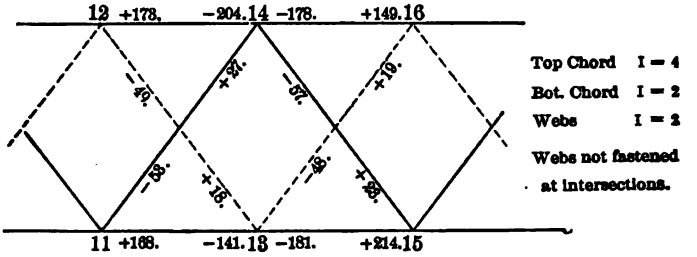

FIG. 38.

Fig. 39 represents a truss in which the diagonals are rigidly connected.

In these diagrams the coefficients of secondary stress are given for each end of all the members of the two panels considered. The most noteworthy feature is the very large stresses in the chord members, these being nearly four times the values given in Table R. The signs

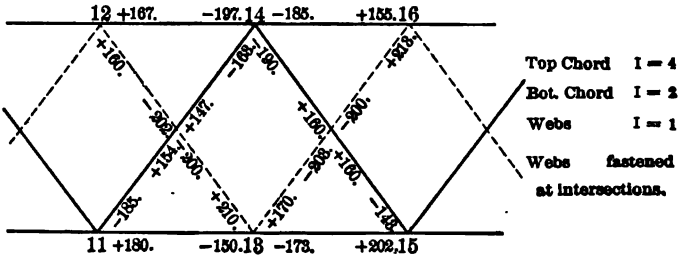

FIG. 39.

of the stresses indicate the downward deflection of joints 11, 14, and 15, relative to the joints adjacent. Assuming a value of c/l of $\frac{1}{40}$, the secondary fibre stresses amount to about 5 units, or 50 per cent of the primary stress. Considering the probability of much larger variations in load than here assumed, it is not unlikely that in double systems the secondary stresses often reach 100 per cent of the primary.

The stresses in the diagonals in Figs. 37 and 38 are not greater than in the single Warren truss, but in Fig. 39 they are relatively high, due to their being fastened at their intersections.

The double Pratt or Whipple truss is evidently subject to about the same effects from concentrated loads as the double Warren.

341. *The Double Triangular Truss with Verticals.*—In the problem of Art. 252, Chapter VI, the equalizing effect of verticals for double triangular trusses was fully demonstrated. Their value in preventing undue secondary stresses is even more important. In the truss there

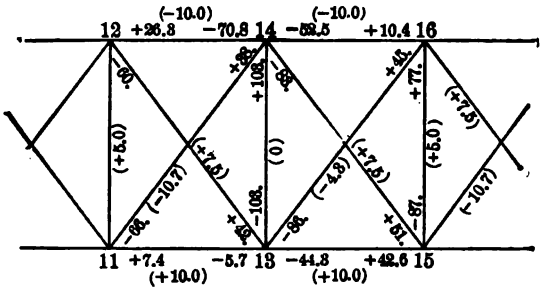

FIG. 40.

analyzed it was shown that the total load on one vertical, with the truss fully loaded, was only about one-fourth of a panel load. With the sections there used the resulting unit stress would be less than half the usual working stress; and, generally, the maximum stresses in these verticals are not likely to exceed this limit. It will therefore be assumed here that, as an extreme variation, alternate verticals may be stressed to one-half the working stress of the chords, and that the other verticals will be unstressed. One set of diagonals will be assumed as stressed to 7.5 units; the other set will have stresses necessarily dependent upon these, and the unit stresses assumed in the chords and verticals. The correct stresses may be calculated by means of eq. (35), giving the relation between the unit stresses of a rectangular figure. Fig. 40 shows (in parentheses) the unit stresses which have been assumed on this basis. They are, therefore, consistent among themselves.

Following the usual methods the secondary stresses have been calculated for the two panels of Fig. 40 and the results are shown in the diagram.

The stresses are seen to be very much less than in the double triangular without verticals and to compare very favorably with the single triangular truss. In fact this truss appears to be one of the most satisfactory forms as regards secondary stresses. If the diagonals are rigidly connected at their intersections, the stresses therein will be increased, but those in the chords will be but little changed. The increase in the diagonal stress will, however, be small compared to the effect of fastening in the double truss without verticals.

342. *The Baltimore Truss.*—It has been seen that, other things being the same, the secondary stresses increase with decrease of panel length. Long panels therefore tend generally to reduce such stresses. In this respect the long panels of the Baltimore or Pettit trusses are advantageous. On the other hand the distortion of the secondary members, the hangers, and the sub-ties or sub-struts, tends greatly to increase the secondary stresses in the main members of such trusses unless the distortion of the secondary members is taken account of to some extent in the construction.

Consider the panel of a Baltimore truss as shown in Fig. 41. The members $O\,O'$ and $O\,N'$ are merely supporting struts for the top chord and vertical post. Suppose the structure be fully loaded and that all the members of the panel are stressed well up to their working value. Assume this working stress to be approximately the same in all the members and let s represent this stress.

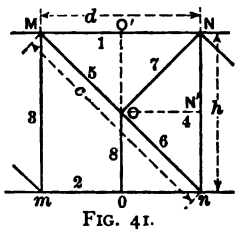

FIG. 41.

The general effect of the strains in the hanger $O\,o$ and the sub-tie $O\,N$ will be to cause the joints o and O' to deflect considerably more than the ends of the respective chord members, and thus to cause considerable bending stress therein. The point N' will also be deflected laterally, bending the post $N\,n$. The exact effect of these strains can be determined only by considering the entire structure, as heretofore, but in this case it will serve our purpose better to calculate the deflections of the joints concerned, and to estimate the bending stresses from this basis.

The deflection of joint o with respect to m and n is calculated by

the usual formula, the stress intensity in each member being s. The calculations are as follows:—

Member.	u	l	$\frac{S}{A}$	$\frac{S u l}{A}$
1	$-\frac{d}{2h}$	d	$-s$	$\frac{s d^2}{2h}$
2	0	d	$+s$	0
3	$-\frac{1}{2}$	h	$-s$	$\frac{s h}{2}$
4	$-\frac{1}{2}$	h	$-s$	$\frac{s h}{2}$
5	$+\frac{c}{2h}$	$c/2$	$+s$	$\frac{s c^2}{4h}$
6	0	$c/2$	$+s$	0
7	$+\frac{c}{2h}$	$c/2$	$+s$	$\frac{s c^2}{4h}$
8	$+1$	$h/2$	$+s$	$\frac{s h}{2}$

The deflection is

$$\Delta_0 = \frac{s}{E}\left(\frac{d^2}{2h} + \frac{3h}{2} + \frac{c^2}{2h}\right). \quad . \quad . \quad . \quad . \quad . \quad (36)$$

Assume that $d = h$, in which case

$$\Delta_0 = \frac{3sh}{E}. \quad . \quad . \quad . \quad . \quad . \quad . \quad . \quad . \quad (37)$$

that is, the deflection of point o relative to m and n is three times the elongation of a tension member of length h under stress s.

The effect of this deflection upon the secondary stresses in $m\,n$ can be estimated on the assumption that $m\,n$ is a beam, fixed at the ends and deflected a distance Δ_0 at the centre. From the table of Art. 7, the deflection in terms of fibre stress is $\Delta = \frac{f l^2}{24\,E\,c}$, where c is half the width of a symmetrical section. We therefore have

$$f = \frac{24\,E\,c}{l^2} \times \Delta_0 = 72\,s\,\frac{c}{l}, \quad . \quad . \quad . \quad . \quad . \quad (38)$$

that is, the secondary stress is equal to the primary stress s, multiplied by $72\,\frac{c}{l}$. In eq. (38) the value of l is equal to the panel length d.

If eye-bars are used the ratio c/l may be about $\frac{1}{150}$, giving a secondary stress of about 50 per cent. If a riveted chord be used of a ratio of c/l of $\frac{1}{60}$ (corresponding to a 50-foot panel and a depth of chord of 20 in.), the secondary stress reaches the very large value of $\frac{72}{60} = 120$ per cent of the primary stress.

Similar calculations for the top chord and vertical post show that the deflections of the centre points relative to the extremities are $\frac{3\,s\,h}{2\,E}$ in each case or one-half as much as for member $m\,n$. These give values for the secondary stresses, under the same assumption as made above, of $36\,s\frac{c}{l}$. For the usual proportions of top chord this is a large value.

These calculations, while not giving actual values of secondary stresses, show the general extent of the deflections produced and the possible magnitude of such stresses. They are obviously of much importance and merit careful attention, especially with respect to the supporting struts for top chord and vertical post. If these supporting struts are made a little longer than the theoretical lengths, excessive stresses under full load may be largely avoided. Large sections and low unit stresses for hangers also aid in reducing deflections and bending stresses in the chord. If a sub-strut, $m\,O$, be used instead of the sub-tie, $O\,N$, it will be found that, assuming the same unit stresses as before, the deflection of o with respect to $m\,n$ is equal to $\frac{s\,h}{E}$, or one-third the value given by eq. (37). Taking into account the fact that the unit stress in the sub-strut would be smaller than in the sub-tie, the relative deflection would be still smaller. It is also found that the deflection of both the top chord and vertical post are also one-third the values when the sub-tie is used. So far as secondary stresses are concerned, therefore, the sub-strut is much the more favorable arrangement.

343. *The Double Triangular Truss with Sub-Panels.*—An analysis of the truss of Fig. 42 will show the same results as obtained by the

use of a sub-strut in Fig. 41. Assuming compression in $a\,b'$ and tension in $b'\,c$, the joint b will deflect a distance $\frac{h\,s}{E}$ with respect to $a\,c$, assuming, as in Art. 342, that the height, h, is equal to a–c, and

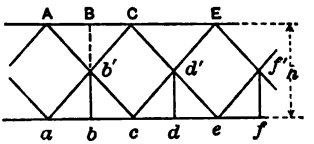

FIG. 42.

that the unit stress, s, is the same for all members. Furthermore, if $B\,b'$ is a supporting strut for the top chord, the deflection of B, with respect to $A\,C$, will be $\frac{h\,s}{2\,E}$, which is the same as in Fig. 41, with the sub-strut $m\,O$. This truss form is, therefore, satisfactory so far as the action of the secondary members is concerned.

344. Secondary Stresses in Longitudinal Members Due to the Action of Lateral Systems.—In Art. 263, the primary stresses in three forms of laterals, such as shown in Figs. 43, 44, and 45, were investigated. In Figs. 43 and 44 the laterals are not affected by the direct stresses in the chords, but in Fig. 45 the lateral diagonals receive considerable direct stress with corresponding stresses in the lateral struts. The secondary stresses in these forms due to the direct stress in the chords will now be determined. The trusses here illustrated represent any truss, in which the longitudinal members are all subjected to stresses of one kind, either compression or tension, such as the upper or lower lateral system of a bridge, or the vertical bent of a trestle tower, or the upper and lower chords of a braced arch.

The principal feature to be considered is the secondary stresses in the chord members. The laterals being of small section, will have small secondary stresses, and their rigidity will have very little influence upon the secondary stresses in the chords. For simplicity, therefore, the laterals will be assumed as pin-ended and omitted in the equations for τ. The moment of inertia of the chord members will be taken as constant and therefore need not appear in the equation. The ratio of depth to panel length will be taken as 3 : 4.

345. *The Single Warren System, Fig.* 43.—The direct stress in the laterals is zero, and that in the chords is taken at -10 per unit area as given in the right half of Fig. 43. This condition causes joints 3 and 4 to deflect downward with respect to joints 2 and 6 or 1 and 5; and, likewise, joints 7 and 8, thus bending the chords into a

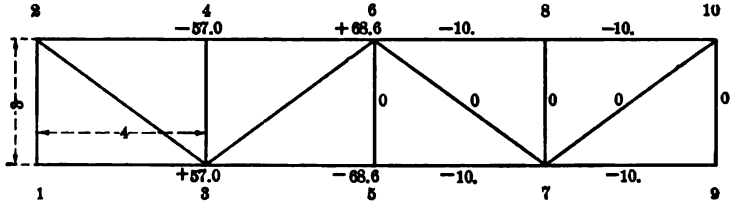

FIG. 43.

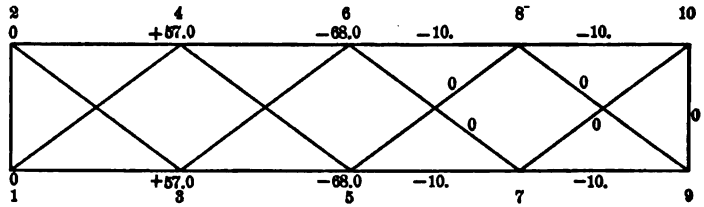

FIG. 44.

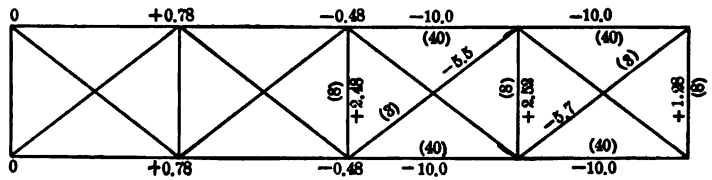

FIG. 45.

sinuous line. Carrying out the calculations as usual, we find the secondary stresses to be as given in Fig. 43 by the figures in the left half of the diagram. The stresses are very considerable. For a value of c/l of 1/50 they amount to 14 per cent of the primary stress at joints 5 and 6.

The form here considered is commonly used for plate girders. In that case, considering flanges alone, the ratio c/l is large, generally at least $\frac{1}{24}$, under the usual requirements of specifications. At a value of 1/20 the secondary stresses amount to 34 per cent of the primary stresses.

346. *The Double Warren System, Fig.* 44.—Here again the direct stresses in the laterals are zero. By eq. (35), Art. 335, the unit distortion along the line 3–4 is $2\,s\,\frac{d^2}{h^2} = 3.55\,s = 35.5$. That along the line 5–6 will be zero. This gives the same conditions as to bending which prevail in Fig. 43; but the direction of bending is different. Joints 3 and 4 bend outward while joints 5 and 6 stand fast. Each alternate joint will thus deflect outwardly, the other joints standing fast.

The stresses are the same numerically as in Fig. 43, and are given in Fig. 44.

347. *Pratt Truss with Double Diagonals, Fig.* 45.—In this case there will exist compressive stresses in the diagonals and tensile stresses in the verticals. Assuming the sectional areas given in parentheses in Fig. 45, and unit stresses of -10 in the chords, the unit stresses in diagonals and struts will be as given in the figure. Then for these unit stresses the secondary stresses have been obtained as before, with the results given in the left half of the diagram of Fig. 45. These are seen to be very small, as compared to the stresses in the other forms considered, and show the great merit of this form of bracing. The struts here assumed are of fairly large section, corresponding to four small angles, but a much smaller size of strut than here assumed would be very advantageous as compared to the forms of Figs. 43 and 44, and should always be used if possible.

348. **Effect of Lacing in Compression Members.**—The usual single and double lacing in columns is arranged in essentially the manner shown in Figs. 43 and 44. At the ends of the members large tie plates serve to prevent any lateral distortion. The effect of the diagonal lacing is then similar to that shown in Arts. 345 and 346; the two elements of the column will be bent laterally in a sinuous curve, resulting in secondary bending stresses of considerable amount. Assuming the direct stress in the lacing to be zero and its connections to be rigid, the stresses will be as shown in Figs. 43 and 44. The ratio of c/l in the case of a column will be comparatively large, generally as much as $1/5$ or $1/6$. With a value of $1/6$ the secondary stresses as here calculated would amount to about 100 per cent of the primary stresses.

It is to be noted, however, that in the form of construction here considered, the assumptions above made are hardly justified. The small ratio of c/l makes the members relatively rigid against lateral bending so that the lacing bars will have an appreciable amount of direct stress due to this resistance. Again, the usual riveted connection of the lacing bars is not absolutely rigid as here assumed, and its distortion will materially reduce the bending in the main members. The actual bending effect will tend to be greatest in large columns, and for such members the advantages of the system of bracing shown in Fig. 45 are very pronounced.

349. Effect of Secondary upon Primary Stresses.—The usual primary stresses are calculated on the assumption of frictionless joints.

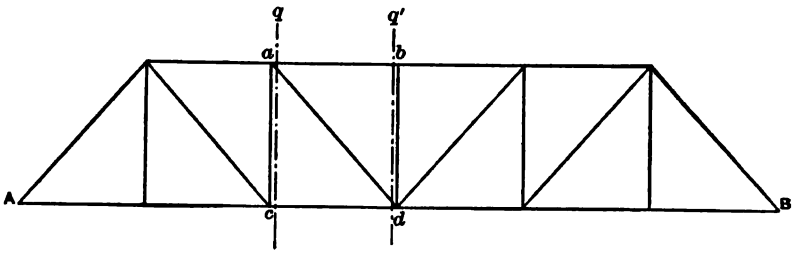

FIG. 46.

The effect of rigid joints is to develop certain bending moments and stresses in the several members, which, as explained in the preceding articles, are called secondary stresses. Obviously, a certain amount of work has been performed by the external loads in producing these secondary stresses, one result of which is to reduce somewhat the primary stresses below the values which would obtain with frictionless joints. Stated in another way, the secondary moments developed render their due proportion of resistance in supporting the external loads.

Assuming the secondary moments to be known, the true primary stresses can readily be determined as follows:—

Suppose the primary stress in $a\,b$, Fig. 46, to be desired. Pass the section q close to joints a and c, and in Fig. 47 represent all external forces and stresses at the cut sections. At each section there will be the primary stress, S, and the secondary moment, M, and shear, V.

The moments and shears are shown acting in a positive direction, according to the notation previously adopted. The secondary moments are supposed to be known, and also the shears, if needed.

To determine stress S_3 take moments about joint a. If M_a is the moment of the external forces (R_1, P_1, and P_2), about joint a, we have

$$S_3 = \frac{M_a + M_{ab} + M_{ad} + M_{cd}}{h}. \quad . \quad . \quad . \quad . \quad . \quad (39)$$

(The moments of the secondary shears are zero, as the sections are supposed to be taken very near the joints.)

For stress in $a\,b$ pass the section q' (Fig. 46), close to joints b and d and take moments about d. Fig. 48 shows the forces acting, the

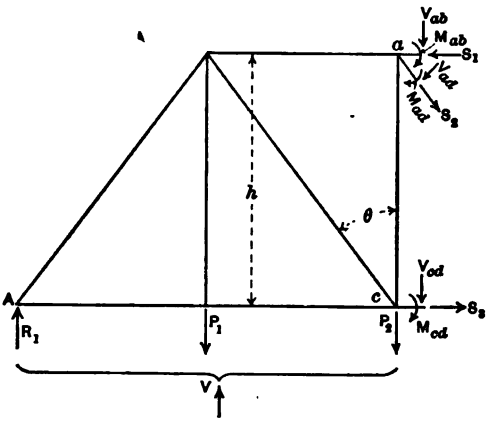

FIG. 47.

secondary moments and shears being again taken as positive. If M_d = external moment about joint d, we have, as before,

$$S_1 = \frac{M_d - M_{ba} - M_{da} - M_{dc}}{h}. \quad . \quad . \quad . \quad . \quad . \quad (40)$$

For stress in the member $a\,d$, we have from Fig. 47,

$$\text{Vert. Comp. } S_2 = V - (V_{ab} + V_{cd} + V_{ad} \cos \theta). \quad . \quad (41)$$

The secondary shears are obtained from the moments by the formula

$$V_{ab} = V_{ba} = (M_{ab} + M_{ba})/l, \text{ etc.}$$

The resulting primary stresses will in general be less than those calculated on the assumption of frictionless joints, but the difference is usually so small as to be of no practical consequence. In some cases, however, where the secondary stresses are especially high, the

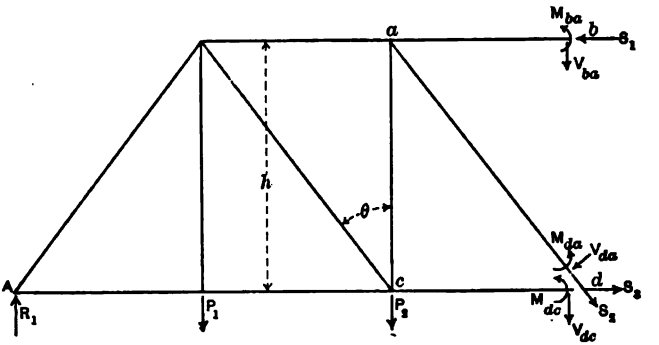

FIG. 48.

primary stresses are materially reduced thereby. Again, since the secondary stresses are calculated on the basis of certain assumed primary stresses, any change in the latter will affect the former in proportion; that is, if the primary stresses are reduced in any case by 5 per cent the secondary stresses will in turn be reduced by an equal proportion. This error in the secondary stresses is of no practical consequence.

EXAMPLE.—As an illustration of the foregoing process, the true primary stresses will be calculated in members 5–6, 4–7, and 5–7 of the truss of Fig. 14, under a load of 1,000 lbs. at each lower joint. The primary stresses under the usual assumptions are given in Fig. 21. The secondary moments are readily found from Table F, using the general formula $M_{nm} = 2K(2\tau_{nm} + \tau_{mn})$. From this we derive the following values needed in the calculation:

$M_{56} = -2{,}830$; $M_{65} = +3{,}380$; $M_{47} = +1{,}045$; $M_{74} = +3{,}210$;
$M_{57} = -268$; $M_{75} = +84$. Then we have

$$S_{47} = 3{,}440 + \left(\frac{-2{,}830 + 1{,}045 - 268}{372}\right) = 3{,}432.$$

$$S_{56} = 3{,}870 - \left(\frac{3{,}380 + 84 + 3{,}210}{372}\right) = 3{,}852.$$

We also derive from the moments:

$$V_{56} = +1.7;\ V_{47} = +13.3;\ V_{57} = +0.4.$$

Then for the stress in 5–7,

Vert. comp. $5\text{–}7 = 500 - (1.7 + 13.3 + 0.4 \times \sin\theta) = 500 - 15 = 485.$

The effect of the secondary stresses in these three cases is to reduce the primary stresses by the following percentages:

In 4–7 by 0.3 per cent.
In 5–6 by 0.5 per cent.
In 5–7 by 0.3 per cent.

It is evident from this example that in trusses of ordinary proportions the effect of the secondary stresses upon the primary stresses

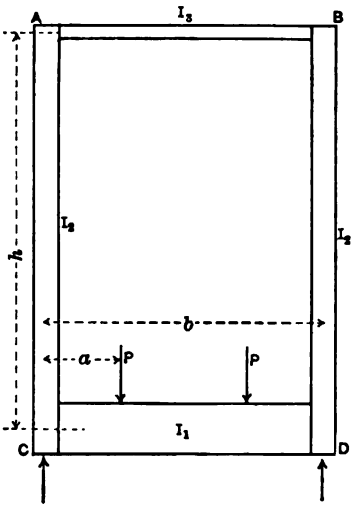

FIG. 49.

is very small. In the case of very shallow trusses with wide members the effect would be considerable.

The effect here considered takes into account only such secondary stresses as have been heretofore discussed, that is, those stresses due to rigidity of joints. Secondary stresses arising from other causes may have a more important effect.

350. Secondary Stresses in Transverse Frames.—The secondary stresses caused in floor-beams and vertical posts, due to rigid connections, may be calculated by the formulas derived in Chapter VI. Where the top strut, *A B* (Fig. 49), is relatively slender, the posts, *A C* and *B D*, may be considered as hinged at the top joints, in which case

the equations of Art. 278 apply. If the transverse or overhead bracing is fairly deep and rigid then the equations of Art. 275 apply. If such sway bracing is very rigid, as in the case of large bridges, the posts may be considered as fixed at the top, and equations of Art. 277 used.

For a single-track structure the moments at C and D are as follows:

For hinged ends at A and B

$$M_c = P \cdot \frac{3\,a\,(b-a)\,I_2}{2\,h\,I_1 + 3\,b\,I_2}. \quad . \quad . \quad . \quad . \quad . \quad (42)$$

For a strut, $A\,B$, of moment of inertia I_3,

$$M_c = \frac{P\,a\,(a-b)\,(2\,h\,I_3 + 3\,b\,I_2)\,I_2}{I_1\,I_3\,h^2 + 2\,b\,h\,(I_1 + I_3)\,I_2 + 3\,b^2\,I_2^2} \quad . \quad . \quad . \quad (43)$$

For upper ends fixed,

$$M_c = P \cdot \frac{2\,a\,(b-a)\,I_2}{h\,I_1 + 2\,b\,I_2}. \quad . \quad . \quad . \quad . \quad . \quad (44)$$

in which h is the distance from the centre of $C\,D$ to the lower edge of the overhead bracing.

For double-track structures it is sufficiently exact to consider each of the loads, P, as the total load on one track, and the distance, a, as the distance to the track centre.

To investigate the relative stresses in the floorbeam and post, consider eq. (42). Let f_1 and f_2 be the bending stresses at C in the beam and post, respectively, and c_1 and c_2 be the widths of these members. Then in general $f_1 = \frac{M\,c_1}{I_1}$ and $f_2 = \frac{M\,c_2}{I_2}$. From eq. (42), we have

$$f_2 = P\,\frac{3\,a\,(b-a)\,c_2}{2\,h\,I_1 + 3\,b\,I_2}.$$

Considering that I_2 is small as compared to I_1, and placing $a = \frac{1}{2}\,b$, we have approximately,

$$f_2 = P\,\frac{3\,a\,(b-a)\,c_2}{2\,h\,I_1} = \frac{9}{32}\,\frac{b^2\,c_2}{h\,I_1}\,P. \quad . \quad . \quad . \quad . \quad (45)$$

If f_w is the working stress in the floorbeam used in its design, we have $f_w = \frac{P\,a\,c_1}{I_1} = \frac{P\,b\,c_1}{4\,I_1}$, whence

$$\frac{f_2}{f_w} = \frac{9}{8}\,\frac{b}{h} \cdot \frac{c_2}{c_1}, \quad . \quad . \quad . \quad . \quad . \quad . \quad (46)$$

that is, the ratio of stress in the post to the working stress in the floorbeam is equal to the ratio of the widths of the respective members, multiplied by $\frac{9}{8}\frac{b}{h}$. For short-span trusses the ratio $\frac{9}{8}\frac{b}{h}$ is from $\frac{1}{2}$ to $\frac{3}{4}$, hence we have approximately $\frac{f_2}{f_w} = \frac{1}{2}\frac{c_1}{c_2}$ to $\frac{3}{4}\frac{c_1}{c_2}$.

Thus if $c_1 = 48$ in. and $c_2 = 16$ in., the stress f_2 will be from 12 per cent to 20 per cent of the working stress f_w.

For fixed ends, the bending stresses in the post will be relatively greater.

The secondary stresses in posts will be made a minimum by the use of deep beams, and posts whose width in the transverse plane is no greater than necessary to secure the desired rigidity as a strut. Where the floorbeams are attached to tension verticals, a narrow section can readily be used.

351. Secondary Stresses in Floor Members Due to the Action of Stringers and Laterals.—Fig. 50 represents the ordinary arrangement of floor members, chords, and laterals, in a single-track railroad bridge.

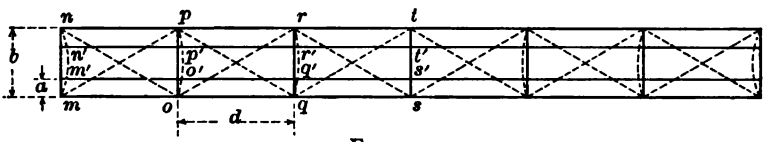

FIG. 50.

The stringers $m'\,o'$, $n'\,p'$, etc., are riveted between the floorbeams, $m\,n$, o, p, etc., and the latter are riveted to the posts at the joints m, n, o, p, etc. At these joints the beams are also more or less rigidly attached to the chord members, m–o–q, etc. The lateral diagonals are also generally fastened to the stringers, but such attachment is not usually a very rigid one.

Assuming a through bridge to be under consideration, the chords will be elongated under stress, and the lateral diagonals will also be stressed in tension in accordance with the analysis of Art. 268, Chapter VI. The total elongation of the entire chord will be equal to $\frac{n\,d\,s}{E}$, where n = number of panels, d = panel length, and s = average unit stress in the chord members. The stringers will be stressed principally

in bending, and their axial length will remain nearly constant. The result of this action of chords and stringers is to cause a horizontal bending of the floorbeams in the direction indicated by the dotted lines.

Assuming the stringers to have no axial stress, the beam $q\,r$ will deflect at points q' and r' a distance $\frac{d\,s}{E}$, the beam $o\,p$, a distance $\frac{2\,d\,s}{E}$, and the end beam $m\,n$, a distance $\frac{3\,d\,s}{E}$. From Table No. 1, Art. 7, the deflection of a beam loaded in this manner and simply supported at the ends, is equal to

$$\Delta = \frac{P\,a^2}{6\,E\,I}(3\,l - 4\,a) = \frac{f\,a}{6\,E\,c}(3\,b - 4\,a), \quad . \quad . \quad (47)$$

in which f = fibre stress due to the deflection, and $2\,c$ = width of beam. From this, we have

$$f = \frac{6\,c\,E\,\Delta}{a\,(3\,b - 4\,a)}. \quad . \quad . \quad . \quad . \quad . \quad . \quad . \quad (48)$$

Then for beam $q\,r$, the first from the centre, we have $\Delta = \frac{d\,s}{E}$ and hence

$$f = \frac{6\,c\,d\,s}{a\,(3\,b - 4\,a)} \quad . \quad . \quad . \quad . \quad . \quad . \quad . \quad (49)$$

as the secondary fibre stress in the beam under the given assumption.

Assuming ordinary values of $d = 300$ in., $s = 10{,}000$ lbs. per sq. in., $b = 192$ in., and $a = 54$ in., we get, for the first beam, $f = 920\,c$. For $c = 6$ in., $f = 5{,}520$ lbs. per sq. in. The second beam will be bent twice as much, and will therefore have a fibre stress of 11,000 lbs. per sq. in., etc.

In these calculations it has been assumed that the stringers are not elongated at all and that the connection to the beams permits of no deformation whatever. Practically the riveted joint is not entirely rigid, as the connection angles, the rivets, and the web of the beam all contribute some deformation. The stringers, also, receive some longitudinal stress, although the amount per square inch of section is small. On the whole, the deflections and stresses in the beams are not as great as deduced from the above calculations, but they are often large and

of much importance. As the calculations show, they increase with the width of the beam and with the number of panels, and are greater as the distance a becomes smaller. In long-span structures, excessive stresses of this kind should be avoided by the use of expansion joints at intervals of a few panels. The use of relatively narrow flanges for the beams is also advisable.

In the above calculations it has been assumed that the beams are hinged, or simply supported at the ends. Where large joint plates are used between laterals, chords, and beams, the connection at the lower flange is quite rigid. The bending of the beam will therefore introduce some secondary stresses in the chords, and at the same time the stresses in the beams will be increased. If the beam and chord connection be considered as perfectly rigid, then the stresses may be found by the general method for secondary stresses, writing out an equation for each of the joints, m, n, o, and p. The changes of angles in the quadrilateral, $q\,q'\,s'\,s$, are readily determined from the known deflection of q relative to q'. This method of calculation is hardly warranted, however, on account of the imperfect rigidity of the various joints. Furthermore, the stresses are still further complicated by the attachment of the laterals to the stringers and beams. Since the chord deformations cannot be much reduced, and since the stringers are of relatively large section and cannot receive much direct stress, it follows that the more rigid the joints and connections of the system are made, the greater will be the secondary stresses due to the bending action which must take place. These conditions properly lead to the design of a floor system, rigid in itself with respect to its main duty, but independent so far as practicable of the action of the chord system of the main trusses. The laterals belong essentially to the main truss system and the stresses developed from chord deformations are readily taken care of.

That serious lateral bending of floorbeams takes place has been shown experimentally in many cases, some examples of which are reported in Bulletin No. 125 of the American Railway Engineering and Maintenance of Way Association, 1910, p. 44. In a 228-ft. span the lateral bending of the end beam added 100 per cent to the stresses due to vertical load in one flange and reduced to zero the stress in the other flange.

352. Deflection of Members Due to Secondary Stresses.—In the analysis of secondary stresses the effect of the deflection of the members themselves upon the stresses has been neglected. In Art. 353 the exact theory is briefly set forth, whereby this effect is taken into account from the beginning and the secondary stresses determined accordingly. That method is very laborious and not generally practicable. It is, however, often desirable to determine approximately the deflection of a member subjected to secondary stresses, especially in the case of

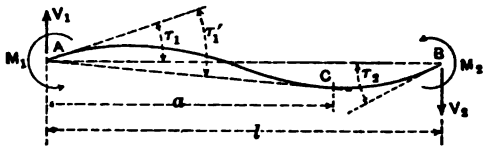

FIG. 51.

compression members, in order that the influence of the secondary stresses upon the buckling action may be estimated.

Having determined the secondary stresses by the methods already described, the deflection of a member at any point can readily be found as follows:

Consider the member $A\,B$, Fig. 51, subjected to end moments and shears as shown. The moment at any point C, distant a from A, is

$$M_c = M_2 - (M_1 + M_2)\frac{l-a}{l} = M_2\frac{a}{l} - M_1\left(\frac{l-a}{l}\right). \qquad (50)$$

Then, as in eq. (8), Art. 304, we have

$$\tau_1' = \frac{a}{6\,EI}(2\,M_1 - M_c), \quad . \quad . \quad . \quad . \quad . \quad (51)$$

also

$$\tau_1 = \frac{l}{6\,EI}(2\,M_1 - M_2). \quad . \quad . \quad . \quad . \quad (52)$$

The deflection of point C is

$$\Delta_c = (\tau_1' - \tau_1)\,a. \quad . \quad . \quad . \quad . \quad . \quad . \quad (53)$$

Substituting from (50), (51), and (52), and reducing, we derive the value

$$\Delta_c = \frac{[M_2(l+a) - M_1(2\,l-a)](l-a)\,a}{6\,EIl}. \quad . \quad . \quad (54)$$

For a maximum value of Δ_c we get, by differentiating eq. (54), the value of $\frac{a}{l}$ is

$$\frac{a}{l} = \frac{M_1}{M_1 + M_2} \pm \sqrt{\left(\frac{M_1}{M_1 + M_2}\right)^2 - \frac{2M_1 - M_2}{3(M_1 + M_2)}}. \quad (55)$$

EXAMPLE.—(1) Let it be required to calculate the deflection of the vertical post 4–5 of the Pratt truss of Fig. 14, under a load of 75,000 lbs. at each of the joints 7, 9, and 11. From Table F we find the moments for this loading to be $M_{45} = -114{,}000$ in.-lbs., and $M_{54} = -121{,}000$ in.-lbs. By eq. (55) we find for the point of maximum deflection, $a/l = .485 \pm .288 = .773$ and .197. Substituting in (54), the deflection at these two points is found to be .007 in., and .010 in., respectively.

(2) Suppose, for example, the end moments in Ex. (1) to be $-120{,}000$ and $+120{,}000$, giving single instead of double curvature. The maximum deflection would be at the centre and, from (54), equal to 0.068 in. The direct stress in the member under the assumed load is 75,000 lbs., which stress, multiplied by the deflection of .068 in., gives a moment of 5,000 in.-lbs., which represents the additional effect due to deflection in the case assumed. The total moment at the centre would then be approximately $120{,}000 + 5{,}000 = 125{,}000$ in.-lbs. The true deflection and moment would be somewhat greater than here calculated, as the effect of the moment of 5,000 in.-lbs. is to increase the deflection still more.

The examples here given indicate that in the ordinary truss the lateral deflection of compression members, due to secondary stresses, is not often of importance in increasing such stresses.

Effect of Transverse Loads.—In the above analysis no account has been taken of transverse loads, such as the weight of horizontal or inclined members. These loads can readily be taken account of in this approximate method of calculation, simply by adding to the deflections caused by the end moments, the deflection caused by the transverse loads, considering the beam as simply supported at the ends. The end moments are then obtained by duly considering the weight of the members in the secondary-stress calculation.

353. Exact Method of Calculating Secondary Stresses.—In the method of analysis explained in the foregoing articles, the bending moments due to the direct or primary stress, acting with an arm equal to the deflection of the member, have been neglected. Manderla's method of solution, published in 1880, was quite remarkable in the fact that while being the first adequate treatment of secondary stresses in general, it was at the same time an exact method, taking

due account of the deflections. This exact method is considerably more laborious than the approximate method heretofore given, and as the results generally differ but little, it will rarely be expedient to resort to the exact process. However, as the method is a valuable one in dealing with certain special problems, it will be given here.

The beam $A\,B$, Fig. 52, is acted upon by the end moments M_1 and M_2, the shears V_1 and V_2, and the direct stress S, which may be

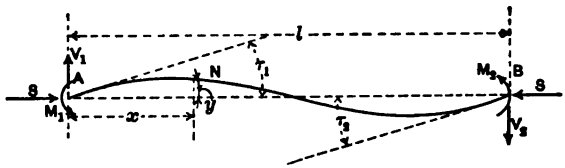

FIG. 52.

either tension or compression. It will be necessary to consider the two cases separately.

a. Compression Members.—The moment at any point N, distant x from A, is

$$M = M_1 + S\,y - V_1\,x \quad . \quad . \quad . \quad . \quad . \quad (56)$$

in which M has the same sign as M_1.

The differential equation of the elastic line is

$$\frac{d^2\,y}{d\,x^2} = -\frac{M}{E\,I} = -\frac{M_1}{E\,I} - \frac{S\,y}{E\,I} + \frac{V_1\,x}{E\,I} \quad . \quad . \quad . \quad (57)$$

Placing $\frac{S}{E\,I} = q^2$ and integrating, we derive the general equation of the curve $A\,B$

$$y = C_1 \sin q\,x + C_2 \cos q\,x - \frac{M_1}{S} + \frac{V_1\,x}{S} \quad . \quad . \quad (58)$$

in which C_1 and C_2 are integration constants to be determined by the conditions of the problem. In this case they are found from the condition that for $x = 0$, $y = 0$, and for $x = l$, $y = 0$. From the first we have

$$0 = C_2 - \frac{M_1}{S} \quad . \quad . \quad . \quad . \quad . \quad . \quad . \quad (a)$$

whence

$$C_2 = \frac{M_1}{S} \cdot \quad l \quad . \quad . \quad . \quad . \quad . \quad . \quad . \quad (59)$$

and from the second

$$0 = C_1 \sin q\,l + C_2 \cos q\,l - \frac{M_1}{S} + \frac{V_1 l}{S} . \quad . \quad . \quad . \quad (b)$$

Substituting the value of C_2 we get

$$C_1 = \frac{M_1}{S} \cdot \frac{1 - \cos q\,l}{\sin q\,l} - \frac{V_1 l}{S \sin q\,l} = \frac{M_1}{S} \tan \frac{q\,l}{2} - \frac{V_1 l}{S \sin q\,l} \quad . \quad (60)$$

The inclination of the elastic line is found by differentiating (58), giving

$$\frac{d\,y}{d\,x} = q\,C_1 \cos q\,x - q\,C_2 \sin q\,x + \frac{V_1}{S} . \quad . \quad . \quad . \quad (61)$$

For $x = 0$ the value of $\frac{d\,y}{d\,x}$ is τ_1, and for $x = l$, $\frac{d\,y}{d\,x} = \tau_2$, whence

$$\tau_1 = q\,C_1 + \frac{V_1}{S} \quad . \quad . \quad . \quad . \quad . \quad . \quad . \quad . \quad . \quad . \quad (c)$$

$$\tau_2 = q\,C_1 \cos q\,l + q\,C_2 \sin q\,l + \frac{V_1}{S} . \quad . \quad . \quad . \quad (d)$$

Substituting values of C_1 and C_2 we derive the formulas

$$\tau_1 = \frac{q\,M_1}{S} \tan \frac{q\,l}{2} - \frac{V_1}{S} \left(\frac{q\,l}{\sin q\,l} - 1 \right) \quad . \quad . \quad . \quad . \quad (62)$$

$$\tau_2 = - \frac{q\,M_1}{S} \tan \frac{q\,l}{2} - \frac{V_1}{S} \left(\frac{q\,l \cos q\,l}{\sin q\,l} - 1 \right) . \quad . \quad . \quad (63)$$

Eliminating $\frac{V_1}{S}$ from these two equations we derive an expression for M_1 in terms of τ_1 and τ_2 and known quantities. It is

$$M_1 = \frac{S}{q} (A\,\tau_1 + B\,\tau_2) \quad . \quad . \quad . \quad . \quad . \quad . \quad (64)$$

in which

$$A = \tfrac{1}{2} \left(\frac{q\,l}{2 - q\,l \cot \frac{q\,l}{2}} + \cot \frac{q\,l}{2} \right) \quad . \quad . \quad . \quad . \quad (65)$$

$$B = \tfrac{1}{2} \left(\frac{q\,l}{2 - q\,l \cot \frac{q\,l}{2}} - \cot \frac{q\,l}{2} \right) . \quad . \quad . \quad . \quad (66)$$

Eq. (64) may be written in the form

$$M_1 = \frac{2S}{q^2 l}\left(\frac{2Aql}{4}\tau_1 + \frac{Bql}{2}\tau_2\right) = \frac{2EI}{l}(2a_c\tau_1 + b_c\tau_2), \quad (67)$$

in which a_c and b_c are coefficients respectively equal to $\frac{Aql}{4}$ and $\frac{Bql}{2}$. They are functions of ql only, which quantities involve l, I, E, and S for the member in question.

We may also write for M_2 the similar expression

$$M_2 = \frac{2EI}{l}(2a_c\tau_2 + b_c\tau_1). \quad . \quad . \quad . \quad . \quad . \quad (68)$$

The values of the coefficients a_c and b_c are conveniently expressed in the form of series. The value of cot θ in general is

$$\cot\theta = \frac{1}{\theta} - \frac{\theta}{3} - \frac{\theta^3}{45} - \frac{2\theta^5}{945} - \text{etc.} \quad . \quad . \quad . \quad (69)$$

From this are derived the values of A and B as follows:

$$A = \frac{4}{ql} - \frac{2ql}{15} - \frac{11(ql)^3}{6{,}300} - \text{etc.} \quad . \quad . \quad . \quad (70)$$

$$B = \frac{2}{ql} + \frac{ql}{30} + \frac{13(ql)^3}{12{,}600} + \text{etc.} \quad . \quad . \quad . \quad (71)$$

and, finally,

$$a_c = \frac{Aql}{4} = 1 - \frac{(ql)^2}{30} - \frac{11(ql)^4}{25{,}000} - \text{etc.} \quad . \quad . \quad (72)$$

$$b_c = \frac{Bql}{2} = 1 + \frac{(ql)^2}{60} + \frac{13(ql)^4}{25{,}000} + \text{etc.} \quad . \quad . \quad (73)$$

The value of ql is $l\sqrt{\frac{S}{EI}}$. If A = area of cross-section, s = unit stress = S/A, and r = radius of gyration, we have the convenient expression for compression members,

$$ql = \frac{l}{r}\sqrt{\frac{s}{E}}. \quad . \quad . \quad . \quad . \quad . \quad . \quad . \quad (74)$$

b. Tension Members.—In case the stress S, Fig. 52, is tensile, the moment at N is

$$M = M_1 - Sy - V_1 x \quad . \quad . \quad . \quad . \quad . \quad . \quad (75)$$

and the differential equation of the elastic line is

$$\frac{d^2y}{dx^2} = -\frac{M_1}{EI} + \frac{Sy}{EI} + \frac{V_1 x}{EI}. \quad . \quad . \quad . \quad . \quad (76)$$

This integrates into the expression

$$y = C_1 e^{qx} + C_2 e^{-qx} + \frac{M_1}{S} - \frac{V_1 x}{S} \quad . \quad . \quad . \quad (77)$$

where $q = \sqrt{\frac{S}{EI}}$ as before, and C_1 and C_2 are integration constants.

For $x = 0$, $y = 0$, and for $x = l$, $y = 0$, whence

$$0 = C_1 + C_2 + \frac{M_1}{S} \quad . \quad . \quad . \quad . \quad . \quad . \quad . \quad . \quad . \quad (a)$$

$$0 = C_1 e^{ql} + C_2 e^{-ql} + \frac{M_1}{S} - \frac{V_1 l}{S}. \quad . \quad . \quad . \quad (b)$$

From these we get the values

$$C_1 = -\frac{M_1}{S}\left(\frac{1 - e^{-ql}}{e^{ql} - e^{-ql}}\right) + \frac{V_1 l}{S}\left(\frac{1}{e^{ql} - e^{-ql}}\right) \quad . \quad . \quad (78)$$

$$C_2 = \frac{M_1}{S}\left(\frac{1 - e^{ql}}{e^{ql} - e^{-ql}}\right) - \frac{V_1 l}{S}\left(\frac{1}{e^{ql} - e^{-ql}}\right). \quad . \quad . \quad (79)$$

The inclination of the elastic line is

$$\frac{dy}{dx} = q C_1 e^{qx} - q C_2 e^{-qx} - \frac{V_1}{S}. \quad . \quad . \quad . \quad (80)$$

Substituting $x = 0$ and $x = l$, we have

$$\tau_1 = q C_1 - q C_2 - \frac{V_1}{S} \quad . \quad . \quad . \quad . \quad . \quad . \quad (81)$$

$$\tau_2 = q C_1 e^{ql} - q C_2 e^{-ql} - \frac{V_1}{S}. \quad . \quad . \quad . \quad . \quad (82)$$

Substituting the values of C_1 and C_2 we have

$$\tau_1 = \frac{M_1}{S} q \left(\frac{e^{ql} - 1}{e^{ql} + 1}\right) + \frac{V_1}{S}\left(\frac{2ql}{e^{ql} - e^{-ql}} - 1\right) \quad . \quad . \quad (83)$$

$$\tau_2 = -\frac{M_1}{S} q \left(\frac{e^{ql} - 1}{e^{ql} + 1}\right) + \frac{V_1}{S}\left(\frac{ql\,(e^{ql} + e^{-ql})}{e^{ql} - e^{-ql}} - 1\right). \quad . \quad (84)$$

In terms of hyperbolic functions, eqs. (83) and (84) transform into

$$\tau_1 = \frac{M_1}{S} q \tanh \frac{q l}{2} + \frac{V_1}{S}\left(\frac{q l}{\sinh q l} - 1\right) \quad . \quad . \quad . \quad (85)$$

$$\tau_2 = -\frac{M_1}{S} q \tanh \frac{q l}{2} + \frac{V_1}{S}\left(\frac{q l \cosh q l}{\sinh q l} - 1\right). \quad . \quad (86)$$

Eliminating V_1 from these equations we derive finally the value for M_1 in terms of τ_1 and τ_2

$$M_1 = \frac{S}{q}(A' \tau_1 + B' \tau_2) \quad . \quad . \quad . \quad . \quad (87)$$

in which

$$A' = \tfrac{1}{2}\left(\frac{q l}{q l \coth \frac{q l}{2} - 2} + \coth \frac{q l}{2}\right) \quad . \quad . \quad . \quad (88)$$

$$B' = \tfrac{1}{2}\left(\frac{q l}{q l \coth \frac{q l}{2} - 2} - \coth \frac{q l}{2}\right) \quad . \quad . \quad . \quad (89)$$

The value of coth θ in the form of a series is

$$\coth \theta = \frac{1}{\theta} + \frac{\theta}{3} - \frac{\theta^3}{45} + \frac{2\theta^5}{945} - \text{etc.} \quad . \quad . \quad . \quad (90)$$

By means of this expression eq. (87) may be transformed into

$$M_1 = \frac{2EI}{l}(2 a_t \tau_1 + b_t \tau_2) \quad . \quad . \quad . \quad . \quad (91)$$

in which

$$a_t = \frac{A' q l}{4} = 1 + \frac{(q l)^2}{30} - \frac{11 (q l)^4}{25{,}000} + \quad . \quad . \quad . \quad (92)$$

$$b_t = \frac{B' q l}{2} = 1 - \frac{(q l)^2}{60} + \frac{13 (q l)^4}{25{,}000} - \quad . \quad . \quad . \quad (93)$$

These two equations differ from the similar equations (72) and (73) only in the signs of the second terms of the series.

Method of Application.—Equations (68) and (91) may be written in the general form

$$M_{nm} = \frac{2EI}{l}(2 a \tau_{nm} + b \tau_{mn}) \quad . \quad . \quad . \quad . \quad (94)$$

corresponding to the general expression for M_{nm} of Art. 308. In the more exact expression here developed the quantities τ_{nm} and τ_{mn} are to be multiplied by the coefficients a and b, whose values differ from unity by the amounts represented by the second and following terms of a series. For compression members the value of $q\,l$ is such as to make the series rapidly convergent so that all terms beyond the second are negligible. For tension members the third term may need to be considered and in extreme cases it will be desirable to use the exact expressions of eqs. (88) and (89).

In applying this exact method to a problem, the sum of the moments at each joint, as given by eq. (94), is placed equal to zero as before. In formulating these equations, the values of the coefficients a and b must be determined for each member and the several values of τ multiplied by the respective coefficients. After this is done the multiplier, $K = I/l$, is used and the work is carried out as in the approximate method. The method of tabulating the values of $\Sigma\ \delta\ \angle$, and formulating the equations, explained in Art. 310, will be modified accordingly.

It is to be observed that in using the exact method of analysis it is necessary to consider the actual total load on the structure for which the stresses are desired in order that the values of the coefficients a and b may be determined. The secondary stresses are no longer proportional to the primary stresses.

The additional labor required by the exact method of solution is not very great, but the increased accuracy secured by the process is not generally of sufficient importance to warrant its use. Some notion of the errors involved in the usual approximate method may be gained by considering the relative size of the terms $\frac{(q\,l)^2}{30}$ and $\frac{(q\,l)^2}{60}$ in eqs. (72), (73), (92), and (93), as compared to unity. For compression members the value of l/r is not often greater than 100 and if $s = 15{,}000$ then $q\,l = \frac{l}{r}\sqrt{\frac{s}{E}} = 2.24$. Then $\frac{(q\,l)^2}{30} = 0.167$ and $\frac{(q\,l)^2}{60} = 0.083$. Hence $a_c = 0.83$ and $b_c = 1.08$. The equation for M_1 then becomes $M_1 = \frac{2\,E\,I}{l}\,(2 \times 0.83\,\tau_1 + 1.08\,\tau_2)$. Generally $q\,l$ will not exceed

1.0, in which case $M_1 = \frac{2EI}{l}(2 \times .965\,\tau_1 + 1.016\,\tau_2)$. For large tension members composed of eye-bars l/r is likely to be about 150, making $q\,l = 3.3$, $a_t = 1.36$, and $b_t = 0.82$. The error of the approximate method is thus greater for tension than for compression members. A matter of more importance, however, is the fact that in the case of compression members the effect of deflection is in general to increase the moments near the centre of the member, especially where the member is of single curvature. This is also fully shown in Art. 352.

354. Stresses in Riveted Expansion Suspenders.—A method sometimes used for providing for expansion is to support the end of the member or truss by means of a vertical plate, rigidly attached at top and bottom, and which permits the desired movement by bending. The plate is thus submitted to combined bending and tension. The conditions are shown in Fig. 53.

FIG. 53.

The stresses in such a plate are readily found by the application of the general formula $M_1 = \frac{2EI}{l}(2\,a_t\,\tau_1 + b_t\,\tau_2)$, given by eq. (91). In this case, since the angle τ is relatively large and l/r is also large, it will be necessary to use the exact values of the coefficients A' and B', given by eqs. (88) and (89). The angles τ_1 and τ_2 are known from the conditions of the problems.

Generally the problem is to determine the stresses in the plate due to a definite deflection Δ, the ends A and B being fixed in direction and the tangents parallel. In this case $\tau_1 = \tau_2 = \tau = \Delta/l$. Then

$$M_1 = \frac{2EI\tau}{l}(2\,a_t + b_t). \quad . \quad . \quad . \quad . \quad . \quad (95)$$

Substituting the values of a_t and b_t from (92), (93), (88), and (89), we have

$$M_1 = \frac{2EI\tau}{l} \cdot \frac{ql}{4}\left(\frac{1}{ql\coth\frac{ql}{2} - 2}\right) = S\Delta \cdot \frac{1}{ql\coth\frac{ql}{2} - 2} \quad (96)$$

EXAMPLE.—Suppose an expansion joint be made by means of a plate $\frac{3}{4}$ in. thick and 6 ft. long to provide for a movement of $\frac{1}{2}$ in. The plate is also subjected to a direct tension of 8,000 lbs. per sq. in. What will be the additional stress due to bending?

Under the given conditions the width of the plate does not affect the result. Consider a width of 1 in. Then $S = 6{,}000$ lbs.; $l = 72$ in.; $I = .0352$ in^4.

$$q^2 = \frac{S}{EI} = \frac{1}{176};\quad q = \frac{1}{13.25};\quad ql = 5.43;\quad \frac{ql}{2} = 2.715.\quad \coth\frac{ql}{2} = 1.01.$$

$$\frac{1}{ql\coth\frac{ql}{2} - 2} = \frac{1}{5.48 - 2} = \frac{1}{3.48}.\quad \text{Whence}\quad M_1 = 6{,}000 \times \frac{1}{2} \times \frac{1}{3.48} =$$

862 in.-lbs. The fibre stress $= f = \dfrac{862 \times 3/8}{.0352} = 9{,}200$ lbs. per sq. in.

The bending stress which would exist if there were no direct stress is found from the formula for deflection of a cantilever beam of length of 36 in. The deflection in terms of fibre stress is $y = \frac{2}{3} \cdot \dfrac{f l^2}{2Ec} = \dfrac{f l^2}{3Ec}$. Placing $y = \Delta/2$ and $l = 36$ in., we derive the value $f = \dfrac{6\,\Delta\,Ec}{l^2}$. In the above example this would be 6,530 lbs. per sq. in., a value 30 per cent less than the true stress. This comparison shows the importance of considering the effect of the direct stress in such problems.

355. Bending Moments in Members Subjected to Transverse Loads and Direct Compression or Tension.—In Art. 353, the effect of transverse loads was not considered. To take account of such loading in an exact manner, the value of M in the general expressions of eqs. (56) and (75) would have to be modified by the moment M' due to the transverse loads, considering the beam as a simply supported one, as in Art. 330. It would be possible then, for any given case, to integrate the resulting expression and finally to derive a value for M_1. Such an expression would, however, be very cumbersome and hardly of practical value. If the members are relatively short and the secondary stresses, or end moments, large, then the method explained in Art. 352 may be used; if the members are long, then the ends may be assumed either as fixed, with horizontal end tangents, or as hinged, as the case may be, and the bending stresses determined as explained below.

a. Compression Members.—Fixed Ends.—The beam $A\,B$, Fig. 54, is subjected to the transverse load of p per unit length, and also to the direct stress S, and the moments and shears as shown. The end

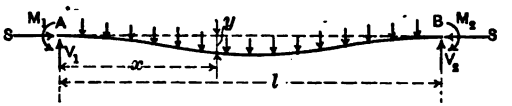

FIG. 54.

tangents are assumed to be horizontal. As in Art. 353 the value of M at any point is

$$M = -M_1 + S\,y + V_1\,x - \frac{p\,x^2}{2} \quad . \quad . \quad . \quad (97)$$

and

$$\frac{d^2\,y}{d\,x^2} = -\frac{M}{E\,I} = \frac{M_1}{E\,I} - \frac{S\,y}{E\,I} - \frac{V_1\,x}{E\,I} + \frac{p\,x^2}{2\,E\,I} \quad . \quad . \quad (98)$$

Placing $q^2 = \frac{S}{E\,I}$, we have, by integration

$$y = C_1 \sin q\,x + C_2 \cos q\,x + \frac{M_1}{S} - \frac{V_1\,x}{S} + \frac{p\,x^2}{2\,S} - \frac{p}{q^2\,S} \quad . \quad (99)$$

For $x = 0$, $y = 0$, and $x = l$, $y = 0$, whence we derive the values

$$C_1 = \frac{V_1}{q\,S} \quad . \quad . \quad . \quad . \quad . \quad . \quad . \quad . \quad . \quad (100)$$

$$C_2 = \frac{p}{q^2\,S} - \frac{M_1}{S} \quad . \quad . \quad . \quad . \quad . \quad . \quad . \quad (101)$$

Also for $x = l$, $\frac{d\,y}{d\,x} = 0$, whence

$$0 = q\,C_1 \cos q\,l - q\,C_2 \sin q\,l - \frac{V_1}{S} + \frac{p\,l}{S} \quad . \quad . \quad . \quad (102)$$

Substituting and reducing $\left(\text{noting that } V_1 = \frac{p\,l}{2}\right)$, we have

$$M_1 = \frac{p}{q^2}\left[1 - \frac{q\,l}{2}\cot\frac{q\,l}{2}\right] \quad . \quad . \quad . \quad . \quad . \quad (103)$$

For small values of $q\,l$, such as occur for compression members, we may express $\cot\frac{q\,l}{2}$ in the form of a series, as in Art. 352, deriving the expression

$$M_1 = \frac{p\,l^2}{12}\left[1 + \frac{(q\,l)^2}{60} + \ldots\right]. \quad . \quad . \quad . \quad (104)$$

But $\frac{p\,l^2}{12}$ is the end moment for a beam with fixed ends and subjected to the transverse load only. Call this moment M'_1. Omitting all terms of the series beyond the second we have then

$$M_1 = M'_1\left(1 + \frac{(q\,l)^2}{60}\right). \quad . \quad . \quad . \quad . \quad (105)$$

The moment at the centre is found from the value of $-E\,I\frac{d^2y}{dx^2}$ for $x = \frac{l}{2}$. From (99) we have

$$\frac{d^2y}{dx^2} = -q^2\,(C_1 \sin q\,x + C_2 \cos q\,x) + \frac{p}{S}. \quad . \quad . \quad (106)$$

Placing $x = \frac{l}{2}$ and inserting values of C_1 and C_2 we have for the centre moment

$$M_c = \frac{p}{q^2}\left(\frac{q\,l}{2}\operatorname{cosec}\frac{q\,l}{2} - 1\right). \quad . \quad . \quad . \quad . \quad (107)$$

Writing $\operatorname{cosec}\frac{q\,l}{2} = \frac{2}{q\,l} + \frac{q\,l}{12} + \frac{7\,(q\,l)^3}{2{,}880} + \ldots$ we derive

$$M_c = \frac{p\,l^2}{24}\left(1 + \frac{7\,(q\,l)^2}{240}\right). \quad . \quad . \quad . \quad . \quad (108)$$

Or, since $\frac{p\,l^2}{24}$ is the centre moment for a beam fixed at the ends, we may call such moment M'_c and we have, finally,

$$M_c = M'_c\left(1 + \frac{7\,(q\,l)^2}{240}\right). \quad . \quad . \quad . \quad . \quad (109)$$

Hinged Ends.—For hinged ends $M_1 = 0$ and the same process as employed in the preceding analysis results in the expression for centre moment

$$M_c = \frac{p}{q^2}\left(\sec\frac{q\,l}{2} - 1\right), \quad . \quad . \quad . \quad . \quad . \quad (110)$$

or approximately

$$M_c = \frac{p\,l^2}{8}\left(1 + \frac{5\,(q\,l^2)}{48}\right). \quad . \quad . \quad . \quad . \quad (111)$$

Placing $\frac{p l^2}{8} = M'_c$ = centre moment for a simply supported beam, we have

$$M_c = M' \left(1 + \frac{5 (q l)^2}{48}\right). \quad . \quad . \quad . \quad . \quad . \quad (112)$$

b. Tension Members.—Fixed Ends.—In the case of tension members the term $S y$ of eq. (98) is negative, giving

$$\frac{d^2 y}{d x^2} = \frac{M_1}{E I} + \frac{S y}{E I} - \frac{V_1 x}{E I} + \frac{p x^2}{2 E I}. \quad . \quad . \quad . \quad (113)$$

This integrates into

$$y = C_1 e^{qx} + C_2 e^{-qx} - \frac{M_1}{S} + \frac{V_1 x}{S} - \frac{p x^2}{2 S} - \frac{p}{q^2 S} \quad . \quad (114)$$

in which $q^2 = \sqrt{\frac{S}{E I}}$ as before.

From (114), we have

$$\frac{d y}{d x} = q (C_1 e^{qx} - C_2 e^{-qx}) + \frac{V_1}{S} - \frac{p x}{S} \quad . \quad . \quad (115)$$

and

$$\frac{d^2 y}{d x^2} = q^2 (C_1 e^{qx} + C_2 e^{-qx}) - \frac{p}{S}. \quad . \quad . \quad . \quad . \quad (116)$$

To determine the constants C_1 and C_2 for a beam fixed at the ends, we use the conditions that for $x = 0$, $\frac{d y}{d x} = 0$ and for $x = \frac{l}{2}$, $\frac{d y}{d x} = 0$, giving

$$0 = q (C_1 - C_2) + \frac{V_1}{S} \quad . \quad . \quad . \quad . \quad . \quad . \quad (a)$$

and

$$0 = q \left(C_1 e^{\frac{ql}{2}} - C_2 e^{-\frac{ql}{2}}\right), \quad . \quad . \quad . \quad . \quad . \quad (b)$$

from which

$$C_2 = C_1 e^{ql} \quad . \quad . \quad . \quad . \quad . \quad . \quad . \quad (117)$$

$$C_1 = \frac{V_1}{q S (e^{ql} - 1)}. \quad . \quad . \quad . \quad . \quad . \quad (118)$$

Then from the condition that for $x = 0$, $y = 0$, we have

$$0 = C_1 + C_2 - \frac{M_1}{S} - \frac{p}{q^2 S}. \quad . \quad . \quad . \quad . \quad . \quad (c)$$

Substituting the values of C_1 and C_2 we get

$$M_1 = -\frac{p}{q^2} + \frac{p\,l}{2\,q}\left[\frac{e^{ql}+1}{e^{ql}-1}\right] \quad . \quad . \quad . \quad . \quad (119)$$

or

$$M_1 = \frac{p}{q^2}\left[\frac{q\,l}{2}\coth\frac{q\,l}{2} - 1\right] . \quad . \quad . \quad . \quad (120)$$

For small values of $q\,l$ we may write $\coth\frac{q\,l}{2}$ as a series, deriving

$$M_1 = \frac{p\,l^2}{12}\left(1 - \frac{(q\,l)^2}{60}\right) \quad . \quad . \quad . \quad . \quad (121)$$

$$= M'_1\left(1 - \frac{(q\,l)^2}{60}\right), \quad . \quad . \quad . \quad . \quad (122)$$

in which M'_1 has the same meaning as in eq. (105). Frequently in the case of tension members the value of $q\,l$ will be too large to permit the form given in eq. (122) to be used.

The centre moment is found in the same manner as for compression members. It is

$$M_c = \frac{p}{q^2}\left[1 - \frac{q\,l}{2}\operatorname{cosech}\frac{q\,l}{2}\right] \quad . \quad . \quad . \quad . \quad (123)$$

and for small values of $q\,l$

$$M_c = \frac{p\,l^2}{24}\left(1 - \frac{7\,(q\,l)^2}{240}\right) \quad . \quad . \quad . \quad . \quad (124)$$

$$= M'_c\left(1 - \frac{7\,(q\,l)^2}{240}\right). \quad . \quad . \quad . \quad . \quad (125)$$

Hinged Ends.—In this case M_1 of eq. (*c*) is zero, hence

$$0 = C_1 + C_2 - \frac{p}{q^2 S}.$$

From this equation, and eq. (*b*), p. 518, we derive

$$C_2 = C_1 e^{ql} \quad . \quad . \quad . \quad . \quad . \quad . \quad . \quad . \quad (126)$$

$$C_1 = \frac{p}{q^2 S\,(1 + e^{ql})}. \quad . \quad . \quad . \quad . \quad . \quad (127)$$

Then from (116)

$$M_c = \frac{p}{q^2}\left(1 - \operatorname{sech}\frac{q\,l}{2}\right). \quad . \quad . \quad . \quad . \quad (128)$$

and for small values of $q\,l$

$$M_c = \frac{p\,l^2}{8}\left(1 - \frac{5\,(q.l)^2}{48}\right) \quad . \quad . \quad . \quad . \quad (129)$$

$$= M'_c\left(1 - \frac{5\,(q\,l)^2}{48}\right). \quad . \quad . \quad . \quad . \quad (130)$$

356. *Approximate General Formulas for Tension and Compression Members.*—A sufficiently exact formula for practical use may be derived on the assumption that the form of the deflection curve is the same as that of an ordinary beam uniformly loaded.

a. Hinged Ends.—From Table 1, p. 10, the deflection of a uniformly loaded beam, simply supported, in terms of fibre stress, is $y = \frac{5}{48}\frac{f\,l^2}{E\,c}$, or very closely, $y = \frac{f\,l^2}{10\,E\,c}$. The bending moment in all cases $= M = \frac{f\,I}{c}$, hence the deflection in terms of the actual bending moment is

$$y = \frac{M\,l^2}{10\,E\,I}. \quad . \quad . \quad . \quad . \quad . \quad . \quad . \quad (131)$$

If M' is the centre moment in an ordinary beam, we have, as in Art. 355,

$$M = M' \pm S\,y \quad . \quad . \quad . \quad . \quad . \quad . \quad . \quad (132)$$

in which the plus sign is to be used for compression members and the minus sign for tension members. Substituting the value of y from (131) and solving for M, we have

$$M = \frac{M'}{1 \mp \frac{S\,l^2}{10\,E\,I}} \quad . \quad . \quad . \quad . \quad . \quad . \quad . \quad (133)$$

in which the plus sign is to be used for tension and the minus sign for compression members.

b. Fixed Ends.—The centre deflection of an ordinary beam with fixed ends, uniformly loaded, is, in terms of the centre moment,

$$y = \frac{M\,l^2}{16\,E\,I}.$$

The effect of the direct stress, S, upon the moments at both end and centre may be placed equal to $S\,y/2$. Hence, for the centre moment,

$$M_c = M' \pm \frac{S y}{2} = M' \pm \frac{S M_c l^2}{32 E I},$$

whence

$$M_c = \frac{M'}{1 \mp \frac{S l^2}{32 E I}}. \quad \ldots\ldots\ldots \quad (134)$$

In terms of the end moment, M_1, the deflection is

$$y = \frac{M_1 l^2}{64 E I},$$

and we derive as before

$$M_1 = \frac{M'}{1 \mp \frac{S l^2}{64 E I}}. \quad \ldots\ldots\ldots \quad (135)$$

In (134) and (135), M' is the moment at the centre and end, respectively $\left(\frac{1}{12} p l^2 \text{ and } \frac{1}{24} p l^2\right)$, in an ordinary beam with fixed ends.

EXAMPLES.—(1) An eye-bar 2 in. wide by 12 in. deep and 40 ft. long is subjected to a direct stress of 12,000 lbs. per sq. in., or a total stress of 288,000 lbs. What is the fibre stress due to bending from its own weight, the bar being assumed as pin-ended?

In this case $p = 80$ lbs. per ft., $l = 480$ in., $I = 288$ in.^{4} Using the approximate formula, eq. (133), we have $\frac{S l^2}{E I} = \frac{288{,}000 \times 480^2}{30{,}000{,}000 \times 288} = 7.7$, and $M = M'/1.77 = \frac{1}{8} p l^2/1.77 = 192{,}000/1.77 = 108{,}000$ in.-lbs. The fibre stress $= f = \frac{108{,}000 \times 6}{288} = 2{,}250$ lbs. per sq. in.

By the exact formula, eq. (128), we have $M = \frac{p}{q^2}\left(1 - \operatorname{sech} \frac{q l}{2}\right)$ $= \frac{p l^2}{8}\left[\frac{8}{(q l)^2}\left(1 - \operatorname{sech} \frac{q l}{2}\right)\right]$. The value of $(q l)^2 = \frac{S l^2}{E I} = 7.7$. Then $\frac{q l}{2} = 1.385$ and $\operatorname{sech} 1.385 = \frac{1}{2.12} = .473$. $M = \frac{p l^2}{8}\left[\frac{8}{7.7} \times (1 - .473)\right]$ $= \frac{p l^2}{8} \times .547 = 192{,}000 \times .547 = 105{,}000$ in.-lbs., a value about 3 per cent less than obtained by the approximate method.

(2) A compression member has the following dimensions: $l = 360$ in., sectional area $= A = 60$ sq. in., $I = 3{,}000$ in.^{4}, depth $= 18$ in. Direct

stress = S = 600,000 lbs. What is the fibre stress due to its own weight, assuming pin ends?

Here $\frac{S\,l^2}{E\,I} = \frac{600{,}000 \times 360^2}{30{,}000{,}000 \times 3{,}000} = 0.865$. Hence the approximate formula gives $M = \frac{M'}{1 - .0865} = \frac{p\,l^2}{8} \times 1.095 = 270{,}000 \times 1.095 = 295{,}600$ in.-lbs. The effect of the deflection is indicated by the term .0865 in the denominator, as compared to unity.

The more exact formula, eq. (112), gives $M = M'\left(1 + \frac{5\,(q\,l^2)}{48}\right)$ $= M'\left(1 + \frac{5}{48} \times .865\right) = M' \times 1.09 = 294{,}000$ in.-lbs., a value agreeing closely with the one found above.

357. Impact Stresses.—*Static and Dynamic Stresses.*—In the analysis of stresses which has preceded, the loads considered have, in all cases, been assumed to be due to the action of gravity alone. In the case of moving loads, the position of the loads has been varied, but the resulting stresses have been calculated on the assumption that at any instant the loads have been stationary. Stated in other words, the dynamic effect of moving loads (the effect due to acceleration or retardation) has not been considered. The stresses thus obtained, whether from dead load or from live load, may properly be called static stresses. In their calculation no account is taken of dynamic effect.

In the design of structures it is necessary, however, to know not only the static stresses involved, but also, as nearly as practicable, the dynamic stresses, so that proper provision may be made for the combined effect. In some structures this dynamic effect is relatively small and unimportant, as, for example, where the fixed load is very large and the moving or variable load is small, or is applied gradually and steadily. Bridges carrying aqueducts, roof trusses, and many types of buildings, are examples of such structures. In other structures the dynamic effect of the live load is very great, as, for example, highway bridges subjected to the action of rapidly moving vehicles or animals, and railroad bridges under fast moving trains. Whatever may be the cause of such dynamic effect, the combined result is generally spoken of as *impact stress.*

In the design of bridges the impact stress is provided for either by increasing the live-load stress in accordance with some empirical rule

supposed to represent the impact, or by a reduction in the live-load working stress below what would be used in case the stress were wholly static. The former method appears to be the more rational one to follow and is coming into general use, especially with respect to railroad structures. In its use the question of the proper amount to add for impact is one not well determined, owing to lack of sufficient experimental data.

The formula in most common use at the present time is probably the one employed in the specifications of the American Railway Engineering and Maintenance of Way Association. It is

$$I = S\frac{300}{300 + L}$$

in which S is the static stress and L the length of span loaded to produce the maximum live-load stress.

To secure more definite information on this subject the Maintenance of Way Association, through a sub-committee, has conducted a large series of experiments, the results of which are published in "Bulletin No. 125," 1910. Experiments were made on about 50 plate girder and truss spans, in which the effect of special test trains, moving at various rates of speed, was determined by means of a deflectometer and several extensometers attached to various members of the structure. Some of the results and the general conclusions contained in this report are here given.

358. *Causes of Impact.*—The chief factors in causing impact in railroad structures are: (1) Unbalanced locomotive drivers; (2) rough and uneven track; (3) flat or irregular wheels; (4) eccentric wheels; (5) rapidity of application of load; (6) deflection of beams and stringers, giving rise to variations in the action of the vertical load.

Where caused by open joints or rough or flat wheels, the impact is more or less in the nature of a "blow" upon the structure; but where caused by the other factors mentioned, it amounts in effect to a varying load, or a series of impulses, acting upon the structure. In either case the result is to produce deflections and stresses in excess of the static values, such excess of stress being commonly called *impact stress* or simply *impact.*

Of all the various causes of impact the fifth one above mentioned, namely, the rapidity of application of the load, is the one which has received the greatest amount of theoretical discussion. The other causes cannot be so readily traced from a theoretical standpoint; experimental determination is the only practical method of determining the results produced. The discussion here given will therefore be divided into, (*a*) effect of speed of application of load, and (*b*) effect of other causes.

359. (*a*) *Effect of Speed of Application of Load.*—Assuming the track perfectly smooth and all of the rotating parts perfectly balanced, the effect of a load moving over a structure at a high rate of speed depends wholly upon the vertical curvature of the track and the effect which this curvature has upon the path over which the centre of gravity of the load travels. If the load causes the structure to deflect so that the curvature of the track is concave upward, the pressure of the load upon the bridge will be in excess of its weight by reason of the centrifugal force caused by such curvature. If the track has an initial camber so that, when the load passes over the structure, the deflection produced is just sufficient to bring the track into a straight line, then there will be no centrifugal force developed and the pressure of the load upon the track will be constant and exactly equal to the static load. The impact in that case will be zero.

If we assume the track originally straight and absolutely rigid, the amount of impact or centrifugal force resulting from the deflection of the structure can be approximately determined on theoretical grounds. Such an analysis has been made by Dr. H. Zimmerman * for the case of a single rolling load, and a formula which is very closely approximate to his exact formula is as follows:

$$F = P \frac{1}{g\, l^2/16\, v^2 d - 3}$$

in which F = centrifugal force, P = weight of rolling load, v = velocity in feet per second, d = deflection of structure, and l = span length. If, for example, d = 1/2,400 of span length and v = 90 ft. per second (about 60 miles per hour), we have

* "Die Schwingungen eines Trägers mit bewegter Last." Berlin.

$$F = P \frac{1}{0.595\, l - 3}$$

a formula which is practically exact for spans greater than 15 feet. For a 25-foot span this gives 8.7 per cent impact, and for a 50-foot span, 3.7 per cent. For a 100-foot span the value would be 1.7 per cent.

Considering these results and the fact that for spans of any considerable length the track is cambered and the abutments not rigid, we may conclude on theoretical grounds that the impact due to speed of application of load, for spans greater than 50 feet, is of no consequence.

The experimental data with reference to this point are very difficult to obtain by reason of other elements which are always present. The results obtained in these tests from balanced compound locomotives are, however, very significant, and indicate that under very favorable conditions as to track and rolling load the impact is of very little consequence even for short spans.

360. (*b*) *Effect of other Causes of Impact.*—The experiments obtained in this series of tests, indicate that with track and rolling stock in good condition the main cause of impact is the unbalanced condition of the drivers of the ordinary locomotive. Various rules are in use for the balancing of locomotives, but, excepting in the case of the balanced four-cylinder locomotive, or the electric locomotive, it is impracticable to balance an engine in all respects. The result aimed at by the mechanical departments is to so counterweight the wheels as to secure a reasonable compromise between the effect of the rotating parts and the reciprocating parts. This requires the use of counterweights considerably in excess of the amount necessary to balance the rotating parts. So far as the vertical effect on the track is concerned the reciprocating parts are of little influence, but by whatever amount the rotating parts are overbalanced, just so far will there be a variation in pressure upon the rail due to the centrifugal force of such overbalance. The amount of such overbalance is such that at high speeds the centrifugal force of this weight becomes a large percentage of the vertical load. In many locomotives, at 80 miles per hour, the excess pressure amounts to more than 100 per cent.

In consequence of the action of these centrifugal forces during the

passage of a train, the load acting upon the bridge is a varying one. It varies with each rotation of the driver, and thus acts as a series of impulses tending to set the structure into vibration. In the case of short-span bridges these impulses will be repeated only two or three times during the passage of the locomotive, but in the case of long-span bridges they will be repeated many times. If now these impulses correspond in period with the normal rate of vibration of the loaded structure, the effect will be cumulative and the vibrations will be greatly increased. Such cumulative effect cannot occur for bridges of very short span length, as the normal rate of vibration of such structures is higher than the rate of rotation of the drivers at the highest practicable speeds. It may and frequently does occur in structures of span lengths as low as 75 feet and sometimes less. The speed at which the impulses here considered show a cumulative effect may be termed the *critical* speed.

In the report here referred to the following formula is derived as expressing the rate of vibration of a loaded bridge:

$$T = \sqrt{\frac{w + p}{p} \times d}$$

in which T = time of vibration of loaded structure in seconds;

w = dead load per foot, assumed as uniform;

p = live load per foot, assumed as uniform;

d = static deflection in feet due to load p, as determined by calculation or direct measurement.

The speed of the train which will produce cumulative vibration, as described above, depends upon the natural rate of vibration of the loaded structure and the diameter of the locomotive drivers. During the passage of a train the total weight on the structure varies to a considerable extent and hence the normal rate of vibration of the structure also varies. Exact agreement, therefore, between driver rotation and vibration period of the structure will exist only for a short time, and hence the cumulative effect will not continue during the passage of the locomotive entirely across a long-span structure. The results of the tests show clearly the importance of the critical speed, and the maximum vibrations were found to occur generally through a narrow range of speed corresponding to this critical speed.

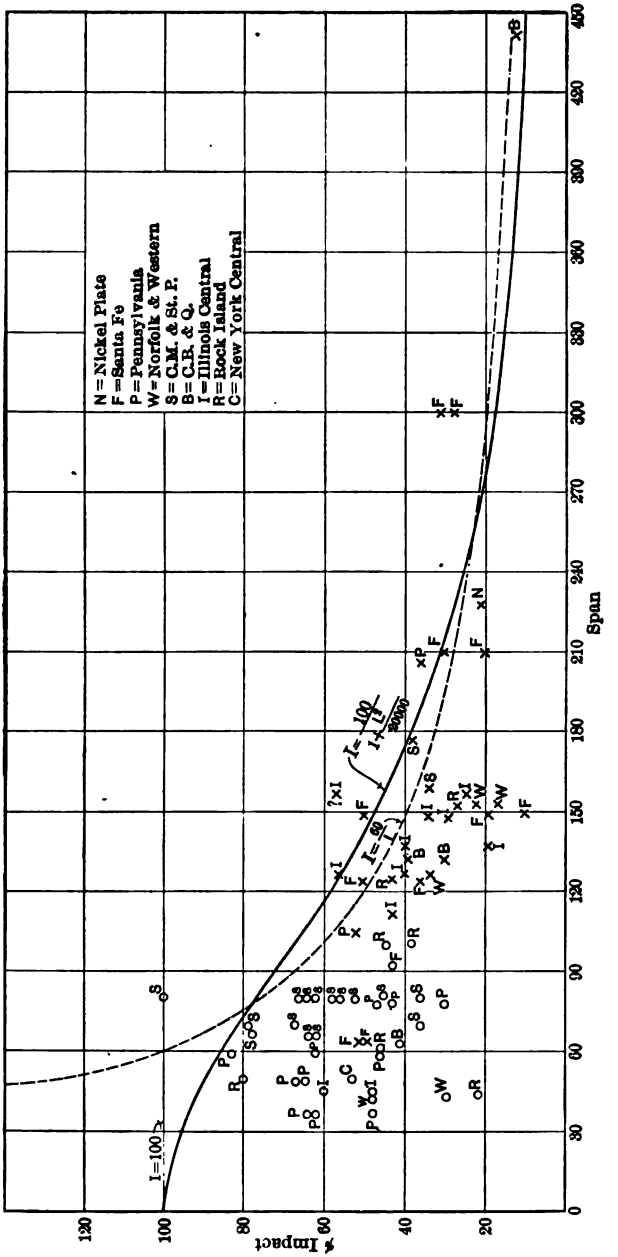

FIG. 55.—Results of Impact Tests. (Bul. 135 Am. Ry. Eng. and M. of W. Assn., 1910.)

361. *General Results for all Spans.*—The most important results obtained are shown in Fig. 55, taken from Plate IX of the "Bulletin." In this diagram are plotted the maximum impact percentages for all of the structures tested, determined by a comparison of the deflection and stresses in flanges and main truss members at high speeds with the same stresses at low speeds. Each point represents a separate structure or series of tests. The curve shown by the full line on the diagram is drawn to represent the maximum percentages as determined by the experiments. So far as our present knowledge goes it may be taken as a reasonable expression of maximum probable impact for ordinary bridge structures.

362. *Impact Percentages for Various Truss Members.*—The percentages referred to in Fig. 55 relate principally to flanges of girders and chords of trusses, all of which are directly affected by vibrations of the structure as a whole. The relative impact in various web members, as compared to chord members, was also investigated and, so far as these tests went, it was found that there was comparatively little difference in the impact ratios for the two classes of members.

363. *Summary of Results of Tests.*—The following summary is taken from the Bulletin:

(1) With track in good condition the chief cause of impact was found to be the unbalanced drivers of the locomotive. Such inequalities of track as existed on the structures tested were of little influence on impact on girder flanges and main truss members of spans exceeding 60 to 75 feet in length.

(2) When the rate of rotation of the locomotive drivers corresponds to the rate of vibration of the loaded structure, cumulative vibration is caused, which is the principal factor in producing impact in long spans. The speed of the train which produces this cumulative vibration is called the "critical speed." A speed in excess of the critical speed, as well as a speed below the critical speed, will cause vibrations of less amplitude than those caused at or near the critical speed.

(3) The longer the span length the slower is the critical speed, and therefore, the maximum impact on long spans will occur at slower speeds than on short spans.

(4) For short spans, such that the critical speed is not reached by the moving train, the impact percentage tends to be constant so far

as the effect of the counterbalance is concerned, but the effect of rough track and wheels becomes of greater importance for such spans.

(5) The impact as determined by extensometer measurements on flanges and chord members of trusses is somewhat greater than the percentages determined from measurements of deflection, but both values follow the same general law.

(6) The maximum impact on web members (excepting hip verticals) occurs under the same conditions which cause maximum impact on chord members, and the percentages of impact for the two classes of members are practically the same.

(7) The impact on stringers is about the same as on plate girder spans of the same length, and the impact on floor beams and hip verticals is about the same as on plate girders of a span length equal to two panels.

(8) The maximum impact percentages as determined by these tests is closely given by the formula:

$$I = \frac{100}{1 + \frac{L^2}{20{,}000}}$$

in which I = impact percentage and L = length of span in feet.

(9) The effect of differences of design was most noticeable with respect to differences in the bridge floors. An elastic floor, such as furnished by long ties supported on widely spaced stringers, or by a ballasted floor, gave smoother curves than were obtained with more rigid floors. The results clearly indicate a cushioning effect with respect to impact due to open joints, rough wheels, and similar causes. This cushioning effect was noticed on stringers, floor beams, hip verticals, and short-span girders.

(10) The effect of design upon impact percentages for main truss members was not sufficiently marked to enable conclusions to be drawn. The impact percentage here considered refers to variations in the axial stresses in the members, and does not relate to vibrations of members themselves.

(11) The impact due to the rapid application of a load, assuming smooth track and balanced loads, is found to be, from both theoretical and experimental grounds, of no practical importance.

(12) The impact caused by balanced compound and electric locomotives was very small and the vibrations caused under the loads were not cumulative.

(13) The effect of rough and flat wheels was distinctly noticeable on floor beams, but not on truss members. Large impact was, however, caused in several cases by heavily loaded freight cars moving at high speeds.

INDEX

A

PAGE

Arch bridges, advantages of 110
definition of 102
deflection of 112, 126, 165, 179
kinds of 102
loads for 104
masonry 103
reactions 104
secondary stresses in 368
Arch ribs, general analysis 106
Arches of three hinges 119
dead-load stresses 119
deflection of 126
equivalent uniform loads for 126
influence lines for 122
lateral trusses 131
live-load stresses 121
reaction lines for 121
reactions and stresses 119
temperature stresses 130
wind stresses 131
Arches of two hinges 134
braced arch 146, 160
circular arch 142
deflection of 165
general formulas 134
influence lines for 151
lateral trusses 166
parabolic arch 139
plate girder 155
reaction lines for 141
ribs 144
stress calculation 150
temperature stresses 141, 159
wind stresses 166
Arches with fixed ends 169
advantages of 185
braced arch 179

PAGE
Arches with fixed ends, deflection of 179
formulas for ribs 169
influence lines for 179, 180
lateral trusses 184
parabolic arch 173, 175
reaction lines 176
temperature stresses 172, 184
wind stresses 184

B

Baltimore truss, counter stresses in 361
secondary stresses in 492
Beams, curved 106, 112
deflection angles of 421
deflection of 1, 106
moments and deflections 10
on multiple supports 412
table of moments, etc 10
Bridge floors, analysis of 412, 420
stresses in I-beam floors 421
Buildings, lateral bracing in 400

C

Cable of suspension bridge. *See* Suspension bridges.
Cantilever bridges 92
advantages of 92
analysis of 96
arrangement 92
deflection of 99
divided support for 99
economy of 94
lateral trusses 101
partially continuous 100
secondary stresses in 472
wind stresses 101
Catenary cable 190
Circular arch 142
Collision strut, effect on secondary stresses 458
Columns, secondary stresses in 497
Combined stresses 515
Compression members, effect of lacing 497
stresses due to weight 515
Continuous girders 15
effect of settlement of supports 18, 41
of several spans 34

PAGE
Continuous girders of three spans 30
of two spans 24
reactions for 23
theorem of three moments 16
use of 41
variable moment of inertia 37
Continuous trusses 40
Counters, stresses in 360
Curved beams, analysis of 112
Curved-chord trusses, lateral stresses 368

D

Deflection due to secondary stresses 506
of arch bridges 112, 165, 179
of beams 1, 112
of cantilever bridges 99
of continuous girders 18
of curved beams 112
of suspension bridges 198, 225, 237, 278
of swing bridges 66, 69, 71
Double intersection trusses 336
secondary stresses in 487
use of 359
Double triangular truss with verticals 349

E

Eccentricity of joints, effect of 462
Elevated railroad bents 391
Equivalent uniform loads for Cooper's *E*-50 53
for swing bridges 65
Expansion suspenders 514
Eye-bars, friction on pins 464
secondary stresses in 515

F

Floorbeams of suspension bridges 323
secondary stresses in 501, 503
Floor members, maximum load on 419

H

Hangers, plate, stresses in 514
of suspension bridges 299, 308

I

PAGE
Impact formulas 523, 529
Impact stresses 522
Influence lines for arches 122, 151, 179
for cantilever bridges 97
for continuous girders 27, 33, 35
for multiple intersection trusses 356
for suspension bridges 221, 224, 244, 250, 257, 264
for swing bridges 59, 70, 83

L

Lateral bracing, deflection of 406
effect of portals on 376
for arches 131, 166, 184
for cantilever bridges 101
for curved chord trusses 369
for skew bridges 377
for suspension bridges 321
for swing bridges 90
for towers 367
for viaducts 394, 400
general analysis of 364
proportions of 369
rigidity of 369
secondary stresses in 495
stresses due to settlement 372
transverse bracing 378
transverse bracing, rigidity of 382
vertical loads 377
See also Quadrangular frames.

M

Manhattan suspension bridge 294, 316
Moment of inertia of a truss 41
Moments in beams, table of 10
in continuous girders 19
Multiple intersection trusses 332

P

Parabolic arches 139, 173
Pettit truss, stresses in counters 361
Pin-connections, friction in 461
secondary stresses in 464

PAGE
Pins, friction of 464
Plate-girder arch 155
Plate-girders. *See* Continuous girders.
Portals, stresses in 376, 383
See also Quadrangular frames.
Pratt truss, secondary stresses in 440, 479
stresses in counters 360
Primary and secondary stresses 423, 498

Q

Quadrangular frames 383
deflection of 406
inclined posts 398, 403
lateral stresses in 394
multiple stories 400
partially trussed 396
posts fixed at one end 389
hinged at one end 390
symmetrical frames 386
temperature stresses in 392
Queen-post truss without counters 410

R

Redundant members, stresses in 332

S

Secondary stresses 423
approximate calculation of 457
due to eccentric joints 462
fixed supports 472
lateral members 495
rigid joints 423
transverse loads 468
weight of members 470
effect of collision strut 458
lacing in columns 497
pin connections 464
effect on primary stresses 498
exact method of calculation 507
in Baltimore trusses 492
columns 497
double intersection trusses 487
floor systems 501, 503

PAGE
Secondary stresses in Pratt trusses 440, 479
transverse frames 501
types of trusses 478
Warren trusses 485
influence lines for 454
Shear, deflection due to 9
Skew bridges, stresses in laterals of 377
Stringers, secondary stresses due to 503
Sub-struts, use of 492
Suspension bridges 186
classification of 186
cable, adjustment of 329
analysis of 186
deformation of 198, 201
form of 186
length of 192
stresses in 195, 200, 213
floorbeam stresses 323
lateral stresses 321
stiffened bridges 209
approximate analysis 212
backstays 249, 259, 264
cable length 192
cable stress 212, 213
comparison of types 274
deflection of 225, 228, 246
deflection of tower 237
economy of 274
erection adjustments 319
exact analysis 276
examples 239, 294
H-component of cable stress 212, 213, 283
hangers of 248, 299, 308
hinged at centre 313
influence lines 221, 224, 228, 244, 250, 257, 264
kinds of 209
Manhattan bridge 238, 294
methods of analysis 211
moment of inertia of truss 302
moments and shears in 212, 220, 235, 250, 264, 278, 316
saddle movement 237
shears in 212, 224, 235, 250, 264, 278
temperature effects 219, 223, 229, 236, 247, 284, 315
towers, deflection of 237
stresses in 325
variable moment of inertia 302
three-hinged bridge 329

PAGE
Suspension bridges, tower stresses 325
two-hinged bridge 330
unstiffened bridges 200
cable stresses in 200
deformation of 201
wind stresses in 323
Swing bridges 43
centre-bearing bridge 46
deflections of 66, 71
end conditions 48
equivalent uniform loads for 65
graphical analysis 68
plate-girder 50
reactions for 46, 66
temperature effects 72
true reactions 66
truss bridges 58
unbroken loads 58
uplift required 71
continuous girder, formulas for 45
double swing bridges 89
end support for 45
general arrangement 43
lateral trusses 90
lift swing bridges 88
loads for 45
partially continuous 80, 82
rim-bearing bridge 73
centre diagonals of 79
continuous over four supports 73
three supports 79
partially continuous 80, 82
reactions for 74, 77, 86
true reactions for 77, 86

T

Temperature stresses in arches 130, 141, 159, 172, 184
in suspension bridges 219, 229, 236, 247, 284, 315
in swing bridges 72
in viaduct bents 392
Tension members, secondary stresses in 515
Three moments, theorem of 16
Top-chord, secondary stresses in 466, 515
Towers, stresses in 325
Transverse bracing, stresses in 378
secondary stresses in 501

PAGE
Trestles, stresses in 365, 403, 495
Trussed beams 408

V

Viaduct bents 391, 399, 403
See also Quadrangular frames.
Vibration of trusses 526

W

Warren truss, secondary stresses in 485
Whipple truss 345
Wind bracing in tall buildings 400
Wind stresses in arch bridges 166, 184
in cantilever bridges 101
in suspension bridges 321
in swing bridges 90

SHORT-TITLE CATALOGUE

OF THE

PUBLICATIONS

OF

JOHN WILEY & SONS, Inc.

NEW YORK

London: CHAPMAN & HALL, Limited

Montreal, Can.: RENOUF PUB. CO.

ARRANGED UNDER SUBJECTS

Descriptive circulars sent on application. Books marked with an asterisk (*) are sold at *net* prices only. All books are bound in cloth unless otherwise stated.

AGRICULTURE—HORTICULTURE—FORESTRY.

ARMSBY—Principles of Animal Nutrition 8vo, $4 00
BOWMAN—Forest Physiography 8vo, *5 00
BRYANT—Hand Book of Logging 8vo, *3 50
BUDD and HANSEN—American Horticultural Manual:
Part I. Propagation, Culture, and Improvement 12mo, 1 50
Part II. Systematic Pomology 12mo, 1 50
CHAPMAN—Forest Valuations ..... (*In Preparation.*)
ELLIOTT—Engineering for Land Drainage 12mo, 2 00
Practical Farm Drainage. (Second Edition, Rewritten) 12mo, 1 50
FULLER—Domestic Water Supplies for the Farm 8vo, *1 50
GRAHAM—Text-book on Poultry ..... (*In Preparation.*)
Manual on Poultry (Loose Leaf Lab. Manual) ..... (*In Preparation.*)
GRAVES—Forest Mensuration 8vo, 4 00
Principles of Handling Woodlands ..... Small 8vo, *1 50
GREEN—Principles of American Forestry 12mo, 1 50
GROTENFELT—Principles of Modern Dairy Practice. (WOLL.) 12mo, 2 00
HAWLEY and HAWES—Forestry in New England 8vo, *3 50
HERRICK—Denatured or Industrial Alcohol 8vo, *4 00
HIRSHFELD and ULBRICHT—Gas Engines for the Farm ..... Small 8vo, *1 50
HOWE—Agricultural Drafting ..... oblong quarto, *1 25
Reference and Problem Sheets to accompany Agricultural Drafting, each *0 20
KEITT—Agricultural Chemistry Text-book ..... (*In Preparation.*)
Laboratory and Field Exercises in Agricultural Chemistry (*In Preparation.*)
KEMP and WAUGH—Landscape Gardening. (New Edition, Rewritten) . 12mo, *1 50
LARSEN—Exercises in Dairying (Loose Leaf Field Manual) ..... 4to, paper, *1 00
Single Exercises each *0 02
and WHITE—Dairy Technology ..... Small 8vo, *1 50
LEVISON—Studies of Trees, Loose Leaf Field Manual, 4to, pamphlet form, Price from 5-15 cents net, each, according to number of pages.
MCCALL—Crops and Soils (Loose Leaf Field Manual) ..... (*In Preparation.*)
Soils (Text-book) ..... (*In Preparation.*)
MCKAY and LARSEN—Principles and Practice of Butter-making 8vo, *1 50
MAYNARD—Landscape Gardening as Applied to Home Decoration 12mo, 1 50
MOON and BROWN—Elements of Forestry ..... (*In Preparation.*)
RECORD—Identification of the Economic Woods of the United States 8vo, *1 25

RECKNAGEL—Theory and Practice of Working Plans (Forest Organization)....8vo, *$2 00
SANDERSON—Insect Pests of Farm, Garden, and Orchard.....Small 8vo, *3 00
and PEAIRS—Injurious Insects.....(*In Preparation.*)
Studies in Insects.....(*In Preparation.*)
SCHWARZ—Longleaf Pine in Virgin Forest.....12mo, *1 25
SOLOTAROFF—Field Book for Street-tree Mapping.....12mo, *0 75
In lots of one dozen.....*8 00
Shade Trees in Towns and Cities.....8vo, *3 00
STOCKBRIDGE—Rocks and Soils.....8vo, 2 50
WINTON—Microscopy of Vegetable Foods.....Large 8vo, 7 50
WOLL—Handbook for Farmers and Dairymen.....16mo, 1 50
YEAW—Exercises on Market Gardening (Loose Leaf Field Manual).
(*In Preparation.*)

ARCHITECTURE.

ATKINSON—Orientation of Buildings or Planning for Sunlight.....8vo, *2 00
BALDWIN—Steam Heating for Buildings.....12mo, 2 50
BERG—Buildings and Structures of American Railroads.....4to, 5 00
BIRKMIRE—Architectural Iron and Steel.....8vo, 3 50
Compound Riveted Girders as Applied in Buildings.....8vo, 2 00
Planning and Construction of High Office Buildings.....8vo, 3 50
Skeleton Construction in Buildings.....8vo, 3 00
BRIGGS—Modern American School Buildings.....8vo, 4 00
BYRNE—Inspection of Materials and Workmanship Employed in Construction.....16mo, 3 00
CARPENTER—Heating and Ventilating of Buildings.....8vo, 4 00
CORTHELL—Allowable Pressure on Deep Foundations.....12mo, *1 25
ECKEL—Building Stones and Clays.....8vo, *3 00
FREITAG—Architectural Engineering.....8vo, 3 50
Fire Prevention and Fire Protection.....16mo, mor., *4 00
Fireproofing of Steel Buildings.....8vo, 2 50
GERHARD—Guide to Sanitary Inspections.....12mo, 1 50
Modern Baths and Bath Houses.....8vo, *3 00
Sanitation of Public Buildings.....12mo, 1 50
Theatre Fires and Panics.....12mo, 1 50
The Water Supply, Sewerage and Plumbing of Modern City Buildings.....8vo, *4 00
GREENBERG and HOWE—Architectural Drafting.....oblong quarto, *1 50
GREENE—Elements of Heating and Ventilation.....8vo, *2 50
HOWE—Agricultural Drafting.....oblong quarto, *1 25
Reference and Problem Sheets to accompany Agricultural Drafting, each, *0 02
JOHNSON—Statics by Algebraic and Graphic Methods.....8vo, 2 00
KELLAWAY—How to Lay Out Suburban Home Grounds.....8vo, 2 00
KIDDER—Architects' and Builders' Pocket-book.....16mo, mor., 5 00
MERRILL—Stones for Building and Decoration.....8vo, 5 00
MONCKTON—Stair-building.....4to, 4 00
PATTON—Practical Treatise on Foundations.....8vo, 5 00
PEABODY—Naval Architecture.....8vo, 7 50
RICE—Concrete-block Manufacture.....8vo, 2 00
RICHEY—Handbook for Superintendents of Construction.....16mo, mor., 4 00
Building Foreman's Pocket Book and Ready Reference.....16mo, mor., 5 00
Building Mechanics' Ready Reference Series: *
Carpenters' and Woodworkers' Edition.....16mo, mor., *1 50
Cement Workers' and Plasterers' Edition.....16mo, mor., *1 50
Plumbers', Steam-Fitters', and Tinners' Edition.....16mo, mor., *1 50
Stone- and Brick-masons' Edition.....16mo, mor., *1 50
RIES—Building Stones and Clay Products.....8vo, *3 00
SABIN—House Painting (Glazing, Paper Hanging and Whitewashing).12mo, 1 00
SIEBERT and BIGGIN—Modern Stone-cutting and Masonry.....8vo, 1 50
SNOW—Principal Species of Wood.....8vo, 3 50
WAIT—Engineering and Architectural Jurisprudence.....8vo, 6 00
Sheep, 6 50
Law of Contracts.....8vo, 3 00
Law of Operations Preliminary to Construction in Engineering and Architecture.....8vo, 5 00
Sheep, 5 50

WILSON—Air Conditioning.....12mo, $1 50
WORCESTER and ATKINSON—Small Hospitals, Establishment and Maintenance, Suggestions for Hospital Architecture, with Plans for a Small Hospital.....12mo, 1 25

ASSAYING.

BETTS—Lead Refining by Electrolysis.....8vo, 4 00
FLETCHER—Practical Instructions in Quantitative Assaying with the Blowpipe.....16mo, mor., 1 50
FURMAN and PARDOE—Manual of Practical Assaying.....8vo, 3 00
LODGE—Notes on Assaying and Metallurgical Laboratory Experiments.8vo, 3 00
LOW—Technical Methods of Ore Analysis. Sixth Edition, Revised....8vo, 3 00
MILLER—Cyanide Process.....12mo, 1 00
Manual of Assaying.....12mo, 1 00
MINET—Production of Aluminum and its Industrial Use. (WALDO.)..12mo, 2 50
PRICE and MEADE—The Technical Analysis of Brass and the Non-Ferrous Alloys.....12mo, *2 00
RICKETTS and MILLER—Notes on Assaying.....8vo, 3 00
ROBINE and LENGLEN—Cyanide Industry. (LE CLERC.).....8vo, 4 00
SEAMON—Manual for Assayers and Chemists.....Small 8vo, *2 50
ULKE—Modern Electrolytic Copper Refining.....8vo, 3 00
WILSON—Cyanide Processes.....12mo, 1 50

ASTRONOMY.

COMSTOCK—Field Astronomy for Engineers.....8vo, 2 50
CRAIG—Azimuth.....4to, 3 50
CRANDALL—Text-book on Geodesy and Least Squares.....8vo, 3 00
DOOLITTLE—Treatise on Practical Astronomy.....8vo, 4 00
HAYFORD—Text-book of Geodetic Astronomy.....8vo, 3 00
HOSMER—Azimuth.....16mo, mor., 1 00
Text-book on Practical Astronomy.....8vo, *2 00
MERRIMAN—Elements of Precise Surveying and Geodesy.....8vo, 2 50
MICHIE and HARLOW—Practical Astronomy.....8vo, *3 00
RUST—Ex-meridian Altitude, Azimuth and Star-Finding Tables.....8vo, 5 00
WHITE—Elements of Theoretical and Descriptive Astronomy.....12mo, *2 00

BIOLOGY.

COHNHEIM—Enzymes.....12mo, *1 50
DAVENPORT—Statistical Methods with Special Reference to Biological Variation. Third Edition, Revised.....16mo, mor., 1 50
EFFRONT and PRESCOTT—Enzymes and Their Applications.....8vo, 3 00
EULER and POPE—General Chemistry of the Enzymes.....8vo, *3 00
MAST—Light and Behavior of Organisms.....8vo, *2 50
PRESCOTT and WINSLOW—Elements of Water Bacteriology, with Special Reference to Sanitary Water Analysis. Third Edition, Rewritten. Small 8vo, *1 75
WARD and WHIPPLE—Freshwater Biology.....(*In Press.*)
WHIPPLE—The Microscopy of Drinking Water.....8vo, 3 50
WINSLOW—The Systematic Relationship of the Coccaceæ.....Small 8vo, 2 50

CHEMISTRY.

ABDERHALDEN—Physiological Chemistry in Thirty Lectures. (HALL and DEFREN.).....8vo, *5 00
ABEGG—Theory of Electrolytic Dissociation. (VON ENDE.).....12mo, *1 25
ALEXEYEFF—General Principles of Organic Syntheses. (MATTHEWS.)..8vo, 3 00

ALLEN (C. M.)—Exercises in General Chemistry, (Loose Leaf Laboratory Manual)....Oblong 4to, paper, *$1 00
Single Exercises, each.... *0 02
Exercises in Quantitative Analysis (Loose Leaf Laboratory Manual). 4to, paper, *1 00
Single Analyses from 2–15 cents net, each, according to number of pages.
ALLEN (J. A.)—Tables for Iron Analysis....8vo, 3 00
ARMSBY—Principles of Animal Nutrition....8vo, 4 00
ARNOLD—Compendium of Chemistry. (MANDEL.)....Small 8vo, 3 50
AUNGST—Technical Chemical Analysis (Loose Leaf Laboratory Manual). 4to, paper, *0 85
Single Analyses from 2–10 cents net, each, according to number of pages.
BERNADOU—Smokeless Powder.—Nitro-cellulose, and Theory of the Cellulose Molecule....12mo, 2 50
BILTZ—Introduction to Inorganic Chemistry. (HALL and PHELAN.)..12mo, *1 25
Laboratory Methods of Inorganic Chemistry. (HALL and BLANCHARD.) 8vo, 3 00
BINGHAM and WHITE—Laboratory Manual of Inorganic Chemistry....12mo, *1 00
BIVINS—Exercises in Qualitative Chemical Analysis (Loose Leaf Lab. Manual)....4to, paper, including work sheet, *1 00
Single Analyses 5, 10 and 15 cents net, each, according to number of pages.
Single work sheets, each.... *0 01
BLANCHARD—Synthetic Inorganic Chemistry....12mo, *1 00
BOTTLER—German and American Varnish Making. (SABIN.)... Small 8vo, *3 50
BROWNE—Handbook of Sugar Analysis....8vo, *6 00
Sugar Tables for Laboratory Use....8vo, *1 25
BROWNING—Introduction to the Rarer Elements....8vo, *1 50
BRUNSWIG—Explosives. (MUNROE and KIBLER.)....Small 8vo, *3 00
CHAMOT—Microchemical Methods....(*In Preparation*).
CLAASSEN—Beet-sugar Manufacture. (HALL and ROLFE.)....8vo, *3 00
CLASSEN—Quantitative Analysis by Electrolysis. (HALL.)....8vo, *2 50
COHN—Indicators and Test-papers....12mo, 2 00
Tests and Reagents....8vo, 3 00
COOPER—Constitutional Analysis by Physico-chemical Methods (Inorganic). (*In Preparation.*)
DANNEEL—Electrochemistry. (MERRIAM.)....12mo, *1 25
DANNERTH—Methods of Textile Chemistry....12mo, 2 00
DUHEM—Thermodynamics and Chemistry. (BURGESS.)....8vo, 4 00
EISSLER—Modern High Explosives....8vo, 4 00
EKELEY—Laboratory Manual of Inorganic Chemistry....12mo, *1 00
FLETCHER—Practical Instructions in Quantitative Assaying with the Blowpipe....16mo, mor., 1 50
FOWLER—Sewage Works Analyses....12mo, 2 00
FRESENIUS—Manual of Qualitative Chemical Analysis. (WELLS.)....8vo, 5 00
Manual of Qualitative Chemical Analysis. Part I. Descriptive. (WELLS.)....8vo, 3 00
Quantitative Chemical Analysis. (COHN.) 2 vols....8vo, 12 50
When Sold Separately, Vol. I, $6. Vol. II, $8.
FUERTES—Water and Public Health....12mo, 1 50
FULLER—Qualitative Analysis of Medicinal Preparations....12mo, *1 50
FURMAN and PARDOE—Manual of Practical Assaying....8vo, 3 00
GETMAN—Exercises in Physical Chemistry....12mo, *2 00
Outlines of Theoretical Chemistry....Small, 8vo, *3 50
GILDEMEISTER and HOFFMANN—The Volatile Oils. Second Edition....8vo, 5 00
GILL—Gas and Fuel Analysis for Engineers....12mo, 1 25
GOOCH—Methods in Chemical Analysis....8vo, *4 00
and BROWNING—Outlines of Qualitative Chemical Analysis.. Small 8vo. *1 25
GROTENFELT—Principles of Modern Dairy Practice. (WOLL.)....12mo, 2 00
GROTH—Introduction to Chemical Crystallography. (MARSHALL.)...12mo, 1 25
HAMMARSTEN—Text-book of Physiological Chemistry. (MANDEL.)....8vo, *4 00
HANAUSEK—Microscopy of Technical Products. (WINTON.)....8vo, 5 00
HASKINS—Organic Chemistry....12mo, *2 00
HERRICK—Denatured or Industrial Alcohol....8vo, *4 00
HINDS—Inorganic Chemistry....8vo, 3 00
Laboratory Manual for Students....12mo, *1 00
HOLLEMAN—Laboratory Manual of Organic Chemistry for Beginners. (WALKER.) Second Edition, Revised....12mo, *1 00

HOLLEMAN—Text-book of Inorganic Chemistry. (COOPER.)....8vo, $2 50
Text-book of Organic Chemistry. (WALKER and MOTT.) Fourth Edition, Revised....8vo, 2 50
HOLLEY—Analysis of Paint and Varnish Products....Small, 8vo, *2 50
Lead and Zinc Pigments....Small 8vo, *3 00
HOPKINS—Oil-chemists' Handbook....8vo, 3 00
JACKSON—Directions for Laboratory Work in Physiological Chemistry..8vo, 1 25
JOHNSON—Rapid Methods for the Chemical Analysis of Special Steels, Steel-making Alloys and Graphite. Second Edition. Rewritten...8vo, *3 00
KEITH—Agricultural Chemistry....(*In Preparation.*)
LANDAUER—Spectrum Analysis. (TINGLE.)....8vo, 3 00
LASSAR-COHN—Application of Some General Reactions to Investigations in Organic Chemistry. (TINGLE.)....12mo, 1 00
LEACH-WINTON—Food Inspection and Analysis. Third Edition. Rewritten by Dr. Andrew L. Winton....8vo, 7 50
LÖB—Electrochemistry of Organic Compounds. (LORENZ.)....8vo, 3 00
LODGE—Notes on Assaying and Metallurgical Laboratory Experiments..8vo, 3 00
LOW—Technical Method of Ore Analysis. Sixth Edition, Revised....8vo, 3 00
LOWE—Paint for Steel Structures....12mo, 1 00
LUNGE—Techno-chemical Analysis. (COHN.)....12mo, 1 00
MCKAY and LARSEN—Principles and Practice of Butter-making....8vo, *1 50
MAIRE—Modern Pigments and their Vehicles....12mo, 2 00
MARTIN—Laboratory Guide to Qualitative Analysis with the Blowpipe. 12mo, *0 60
MASON—Examination of Water. (Chemical and Bacteriological.)....12mo, 1 25
Water-supply. (Considered Principally from a Sanitary Standpoint.) 8vo, 4 00
MATHEWSON—First Principles of Chemical Theory....8vo, *1 00
MATTHEWS—Laboratory Manual of Dyeing and Textile Chemistry....8vo, 3 50
Textile Fibres. Third Edition. Rewritten....8vo, *4 00
MEYER—Determination of Radicles in Carbon Compounds. (TINGLE.) Third Edition....12mo, *1 25
MILLER—Cyanide Process....12mo, 1 00
Manual of Assaying....12mo, 1 00
MINET—Production of Aluminum and its Industrial Use. (WALDO.)..12mo, 2 50
MITTELSTAEDT—Technical Calculations for Sugar Works. (BOURBAKIS.) 12mo, *1 50
MIXTER—Elementary Text-book of Chemistry....12mo, 1 50
MORGAN—Elements of Physical Chemistry....12mo, 3 00
Physical Chemistry for Electrical Engineers....12mo, *1 50
MOORE—Experiments in Organic Chemistry....12mo, *0 50
Outlines of Organic Chemistry....12mo, *1 50
MORSE—Calculations used in Cane-sugar Factories....16mo, mor., 1 50
MUIR—History of Chemical Theories and Laws....8vo, *4 00
MULLIKEN—General Method for the Identification of Pure Organic Compounds. Vol. I. Compounds of Carbon with Hydrogen and Oxygen....Large 8vo, 5 00
Vol. II. Nitrogenous Compounds....(*In Preparation.*)
Vol. III. The Commercial Dyestuffs....Large 8vo, 5 00
NELSON—Analysis of Drugs and Medicines....12mo, *3 00
OSTWALD—Conversations on Chemistry. Part One. (RAMSEY.)....12mo, 1 50
Part Two. (TURNBULL.).12mo, 2 00
Introduction to Chemistry. (HALL and WILLIAMS.)....Small 8vo, *1 50
OWEN and STANDAGE—Dyeing and Cleaning of Textile Fabrics....12mo, 2 00
PALMER—Practical Test Book of Chemistry....12mo, *1 00
PAULI—Physical Chemistry in the Service of Medicine. (FISCHER.)..12mo, *1 25
PICTET—Alkaloids and their Chemical Constitution. (BIDDLE.)....8vo, 5 00
PRESCOTT and WINSLOW—Elements of Water Bacteriology, with Special Reference to Sanitary Water Analysis. Third Edition, Rewritten. Small 8vo, *1 75
REISIG—Guide to Piece-Dyeing....8vo, *25 00
RICHARDS and WOODMAN—Air, Water, and Food from a Sanitary Standpoint....8vo, 2 00
RICKETTS and MILLER—Notes on Assaying....8vo, 3 00
RIDEAL—Disinfection and the Preservation of Food....8vo, 4 00
RIGGS—Elementary Manual for the Chemical Laboratory....8vo, 1 25
ROBINE and LENGLEN—Cyanide Industry. (LE CLERC.)....8vo, 4 00

ROGERS—Exercises in Industrial Chemistry (Loose Leaf Laboratory Manual). (*In Preparation.*)

RUDDIMAN—Incompatibilities in Prescriptions	8vo,	$2 00
Whys in Pharmacy	12mo,	1 00
RUER—Elements of Metallography. (MATHEWSON.)	8vo,	*3 00
SABIN—Industrial and Artistic Technology of Paint and Varnish	8vo,	3 00
SALKOWSKI—Physiological and Pathological Chemistry. (ORNDORFF.)	8vo,	2 50
SCHIMPF—Essentials of Volumetric Analysis	Small 8vo,	*1 50
Manual of Volumetric Analysis	8vo,	5 00
Qualitative Chemical Analysis	8vo,	*1 25
SEAMON—Manual for Assayers and Chemists	Small 8vo,	*2 50
SMITH—Lecture Notes on Chemistry for Dental Students	8vo,	*2 50
SPENCER—Handbook for Cane Sugar Manufacturers	16mo, mor.,	3 00
Handbook for Chemists of Beet-sugar Houses	16mo, mor.,	3 00
STOCKBRIDGE—Rocks and Soils	8vo,	2 50
STONE—Practical Testing of Gas and Gas Meters	8vo,	3 50
TILLMAN—Descriptive General Chemistry	8vo,	*3 00
Elementary Lessons in Heat	8vo,	*1 50
TREADWELL—Qualitative Analysis. (HALL.)	8vo,	3 00
Quantitative Analysis. (HALL.)	8vo,	4 00
TURNEAURE and RUSSELL—Public Water-supplies	8vo,	5 00
VENABLE—Methods and Devices for Bacterial Treatment of Sewage	8vo,	3 00
WARD and WHIPPLE—Freshwater Biology	(*In Press.*)	
WARE—Beet-sugar Manufacture and Refining. Vol. I	8vo,	4 00
Vol. II	8vo,	5 00
WASHINGTON—Manual of the Chemical Analysis of Rocks	8vo,	2 00
WEAVER—Military Explosives	8vo,	*3 00
WELLS—Laboratory Guide in Qualitative Chemical Analysis	8vo,	1 50
Short Course in Inorganic Qualitative Chemical Analysis for Engineering Students	12mo,	1 50
Text-book of Chemical Arithmetic	12mo,	1 25
WHIPPLE—Microscopy of Drinking-water	8vo,	3 50
WILSON—Cyanide Processes	12mo,	1 50
WIECHMANN—Sugar Analysis. Third Edition, Revised	Small 8vo,	*3 00
WINTON—Microscopy of Vegetable Foods	8vo,	7 50
ZSIGMONDY—Colloids and the Ultramicroscope. (ALEXANDER.)	Small 8vo,	3 00

CIVIL ENGINEERING.

BRIDGES AND ROOFS, HYDRAULICS, MATERIALS OF ENGINEERING. RAILWAY ENGINEERING.

AMERICAN CIVIL ENGINEERS' POCKET BOOK. (MANSFIELD MERRIMAN, Editor-in-chief.)	16mo, mor.,	*5 00
BAKER—Engineers' Surveying Instruments	12mo,	3 00
BIXBY—Graphical Computing Table	Paper 19¼ ×24¼ inches,	0 25
BREED and HOSMER—Principles and Practice of Surveying.		
Vol. I. Elementary Surveying	8vo,	3 00
Vol. II. Higher Surveying	8vo,	2 50
BURR—Ancient and Modern Engineering and the Isthmian Canal	8vo,	*3 50
COMSTOCK—Field Astronomy for Engineers	8vo,	2 50
CORTHELL—Allowable Pressure on Deep Foundations	12mo,	*1 25
CRANDALL—Text-book on Geodesy and Least Squares	8vo,	3 00
DAVIS—Elevation and Stadia Tables	8vo,	1 00
ELLIOTT—Engineering for Land Drainage	12mo,	2 00
FIEBEGER—Treatise on Civil Engineering	8vo,	*5 00
FLEMER—Phototopographic Methods and Instruments	8vo,	5 00
FOLWELL—Sewerage. (Designing and Maintenance.)	8vo,	3 00
FOWLER—Sub-Aqueous Foundations	(*In Press.*)	
FREITAG—Architectural Engineering	8vo,	3 50
HAUCH and RICE—Tables of Quantities for Preliminary Estimates	12mo,	*1 25
HAYFORD—Text-book of Geodetic Astronomy	8vo,	3 00
HERING—Ready Reference Tables. (Conversion Factors.)	16mo, mor.,	2 50

HESS—Graphics and Structural Design.....8vo, *$3 00
HOSMER—Azimuth.....16mo, mor., 1 00
Text-book on Practical Astronomy.....8vo, *2 00
HOWE—Retaining Walls for Earth. Sixth Edition, Revised.....12mo, 1 25
IVES—Adjustments of the Engineer's Transit and Level.....16mo, bds., *0 25
and HILTS—Problems in Surveying, Railroad Surveying and Geodesy.....16mo, mor., 1 50
JOHNSON (J. B.) and SMITH—Theory and Practice of Surveying. Small 8vo, *3 50
(L. J.)—Statics by Algebraic and Graphic Methods.....8vo, 2 00
KINNICUTT, WINSLOW and PRATT—Sewage Disposal.....8vo, *3 00
KIRBY—Elements of Specification Writing.....8vo, *1 25
MAHAN—Descriptive Geometry.....8vo, *1 50
MARSTON and ERINGER—Sewers and Drains.....(*In Preparation.*)
MERRIMAN—Elements of Precise Surveying and Geodesy.....8vo, 2 50
and BROOKS—Handbook for Surveyors.....16mo, mor., 2 00
NUGENT—Plane Surveying.....8vo, 3 50
OGDEN—Sewer Construction.....8vo, 3 00
Sewer Design. Second Edition. Rewritten.....8vo, *2 00
and CLEVELAND—Practical Methods of Sewage Disposal for Residences, Hotels, and Institutions.....8vo, *1 50
PARSONS—Disposal of Municipal Refuse.....8vo, 2 00
PATTON—Treatise on Civil Engineering.....8vo, half leather, 7 50
REED—Topographical Drawing and Sketching.....4to, 5 00
RIEMER—Shaft-sinking under Difficult Conditions. (CORNING and PEELE.)
8vo, 3 00
SIEBERT and BIGGIN—Modern Stone-cutting and Masonry.....8vo, 1 50
SMITH—Manual of Topographical Drawing. (MCMILLAN.).....8vo, 2 50
SOPER—Air and Ventilation of Subways.....12mo, 2 50
TRACY—Exercises in Surveying.....12mo, mor., *1 00
Plane Surveying.....16mo, mor., 3 00
VENABLE—Garbage Crematories in America.....8vo, 2 00
Methods and Devices for Bacterial Treatment of Sewage.....8vo, 3 00
WAIT—Engineering and Architectural Jurisprudence.....8vo, 6 00
Sheep, 6 50
Law of Contracts.....8vo, 3 00
Law of Operations Preliminary to Construction in Engineering and Architecture.....8vo, 5 00
Sheep, 5 50
WARREN—Stereotomy—Problems in Stone-cutting.....8vo, 2 50
WATERBURY—Vest-Pocket Hand-book of Mathematics for Engineers.
2½ × 5½ inches, mor., *1 00
Enlarged Edition, Including Tables.....mor., *1 50
WEBB—Problems in the Use and Adjustment of Engineering Instruments.
16mo, mor., 1 20
WILSON—Topographic, Trigonometric and Geodetic Surveying 8vo, 3 55

BRIDGES AND ROOFS.

BISHOP—Drafting Forms. Loose Leaf Sheets, each..... *0 02
Structural Details of Hip and Valley Rafters.....Oblong large 8vo. *1 75
Structural Drafting.....(*In Press.*)
BOLLER—Practical Treatise on the Construction of Iron Highway Bridges
8vo, 2 00
Thames River Bridge.....Oblong paper, *5 00
BURR—Suspension Bridges.....8vo, *4 50
and FALK—Design and Construction of Metallic Bridges.....8vo, 5 00
Influence Lines for Bridge and Roof Computations.....8vo, 3 00
DU BOIS—Mechanics of Engineering. Vol. II.....Small 4to, 10 00
FOSTER—Treatise on Wooden Trestle Bridges. Fourth Edition.....4to, *5 00
GREENE—Arches in Wood, Iron, and Stone.....8vo, 2 50
Bridge Trusses.....8vo, 2 50
Roof Trusses.....8vo, 1 25
GRIMM—Secondary Stresses in Bridge Trusses.....8vo, 2 50
HELLER—Stresses in Structures and the Accompanying Deformations.
8vo, 3 00

HOWE—Design of Simple Roof-trusses in Wood and Steel.....8vo, $2 00
Influence Lines for the Determination of Maximum Moments in Beams and Trusses.....(*In Press.*)
Symmetrical Masonry Arches. Second Edition, Revised.....8vo, *2 50
Treatise on Arches.....8vo, 4 00
HUDSON—Deflections and Statically Indeterminate Stresses.....Small 4to, *3 50
Plate Girder Design.....8vo, *1 50
JACOBY—Structural Details, or Elements of Design in Heavy Framing. 8vo, *2 25
JOHNSON, BRYAN and TURNEAURE—Theory and Practice in the Designing of Modern Framed Structures. New Edition.
Part I. Stresses in Simple Structures.....8vo, *3 00
Part II. Statically Indeterminate Structures and Secondary Stresses 8vo, *4 00
MERRIMAN and JACOBY—Text-book on Roofs and Bridges:
Part I. Stresses in Simple Trusses.....8vo, 2 50
Part II. Graphic Statics.....8vo, 2 50
Part III. Bridge Design.....8vo, 2 50
Part IV. Higher Structures.....8vo, 2 50
RICKER—Design and Construction of Roofs.....8vo, 5 00
SONDERICKER—Graphic Statics, with Applications to Trusses, Beams, and Arches.....8vo, *2 00
WADDELL—De Pontibus, Pocket-book for Bridge Engineers....16mo, mor., 2 00
Specifications for Steel Bridges.....12mo, *0 50

HYDRAULICS.

BARNES—Ice Formation.....8vo, 3 00
BAZIN—Experiments upon the Contraction of the Liquid Vein Issuing from an Orifice. (TRAUTWINE.).....8vo, 2 00
BOVEY—Treatise on Hydraulics.....8vo, 5 00
CHURCH—Diagrams of Mean Velocity of Water in Open Channels. Oblong 4to, paper, 1 50
Hydraulic Motors.....8vo, 2 00
Mechanics of Fluids (Being Part IV of Mechanics of Engineering)..8vo, 3 00
COFFIN—Graphical Solution of Hydraulic Problems.....16mo, mor., 2 50
FLATHER—Dynamometers, and the Measurement of Power.....12mo, 3 00
FOLWELL—Water-supply Engineering.....8vo, 4 00
FRIZELL—Water-power.....8vo, 5 00
FUERTES—Water and Public Health.....12mo, 1 50
FULLER—Domestic Water Supplies for the Farm.....8vo, *1 50
GANGUILLET and KUTTER—General Formula for the Uniform Flow of Water in Rivers and Other Channels. (HERING and TRAUTWINE.)...8vo, 4 00
HAZEN—Clean Water and How to Get It. Second Edition.....Small 8vo, 1 50
Filtration of Public Water-supplies.....8vo, 3 00
HAZELHURST—Towers and Tanks for Water-works.....8vo, 2 50
HERSCHEL—115 Experiments on the Carrying Capacity of Large, Riveted, Metal Conduits.....8vo, 2 00
HOYT and GROVER—River Discharge.....8vo, 2 00
HUBBARD and KIERSTED—Water-works Management and Maintenance, 8vo, 4 00
LYNDON—Development and Electrical Distribution of Water Power..8vo, *3 00
MASON—Water-supply. (Considered Principally from a Sanitary Standpoint.).....8vo, 4 00
MERRIMAN—Elements of Hydraulics.....12mo, *1 00
Treatise on Hydraulics. 9th Edition, Rewritten.....8vo, *4 00
MOLITOR—Hydraulics of Rivers, Weirs and Sluices.....8vo, *2 00
MORRISON and BRODIE—High Masonry Dam Design.....8vo, *1 50
RECTOR—Underground Waters for Commercial Purposes.....12mo, *1 00
SCHUYLER—Reservoirs for Irrigation, Water-power, and Domestic Water supply. Second Edition, Revised and Enlarged.....Large 8vo, 6 00
THOMAS and WATT—Improvement of Rivers. Second Edition, 2 Vols. 4to, *7 50
TURNEAURE and RUSSELL—Public Water-supplies.....8vo, 5 00
WEGMANN—Design and Construction of Dams. 6th Ed., enlarged.....4to, *6 00
Water Supply of the City of New York from 1658 to 1895.....4to, 10 00

WHIPPLE—Value of Pure Water.....Small 8vo, $1 00
WHITE—Catskill Water Supply of New York City.....8vo, *6 00
WILLIAMS and HAZEN—Hydraulic Tables.....8vo, 1 50
WILSON—Irrigation Engineering.....8vo, 4 00
WOOD—Turbines.....8vo, 2 50

MATERIALS OF ENGINEERING.

BAKER—Roads and Pavements. Second Edition, Revised.....8vo, 5 00
Treatise on Masonry Construction.....8vo, 5 00
BLACK—United States Public Works.....Oblong 4to, 5 00
BLANCHARD and DROWNE—Highway Engineering, as Presented at the Second International Road Congress, Brussels, 1910.....8vo, *2 00
Text-book on Highway Engineering.....8vo, *4 50
BOTTLER—German and American Varnish Making. (SABIN.)...Small 8vo, *3 50
BURR—Elasticity and Resistance of the Materials of Engineering.....8vo, 7 50
BYRNE—Highway Construction.....8vo, 5 00
Inspection of the Materials and Workmanship Employed in Construction. 16mo, 3 00
CHURCH—Mechanics of Engineering.....8vo, 6 00
Mechanics of Solids (Being Parts I, II, III of Mechanics of Engineering).....8vo, 4 50
Mechanics of Fluids (Being Part IV of Mechanics of Engineering).8vo, 3 00
DU BOIS—Mechanics of Engineering:
Vol. I. Kinematics, Statics, Kinetics.....Small 4to, 7 50
ECKEL—Building Stones and Clays.....8vo, *3 00
Cements, Limes, and Plasters.....8vo, *6 00
FULLER and JOHNSTON—Applied Mechanics:
Vol. I. Theory of Statics and Kinetics.....8vo, *2 50
Vol. II. Strength of Materials.....(*In Preparation.*)
GREENE—Structural Mechanics.....8vo, *2 50
HOLLEY—Analysis of Paint and Varnish Products.....Small 8vo, *2 50
Lead and Zinc Pigments.....Small 8vo, *3 00
HUBBARD—Dust Preventives and Road Binders.....8vo, *3 00
JOHNSON—Materials of Construction.....Large 8vo, 6 00
KEEP—Cast Iron.....8vo, 2 50
KING—Elements of the Mechanics of Materials and of Power of Transmission.....8vo, *2 50
LANZA—Applied Mechanics.....8vo, 7 50
LOWE—Paints for Steel Structures.....12mo, 1 00
MAIRE—Modern Pigments and their Vehicles.....12mo, 2 00
MAURER—Technical Mechanics.....8vo, 4 00
MERRILL—Stones for Building and Decoration.....8vo, 5 00
MERRIMAN—Mechanics of Materials.....8vo, 5 00
Strength of Materials.....12mo, *1 00
METCALF—Steel. A Manual for Steel-users.....12mo, 2 00
MILLS—Materials for Construction.....(*In Press.*)
MORRISON—Highway Engineering.....8vo, 2 50
MURDOCK—Strength of Materials.....12mo, *2 00
PATTON—Practical Treatise on Foundations.....8vo, 5 00
RICE—Concrete Block Manufacture.....8vo, 2 00
RICHARDSON—Modern Asphalt Pavement.....8vo, 3 00
RICHEY—Building Foreman's Pocket Book and Ready Reference.16mo,mor., 5 00
Cement Workers' and Plasterers' Edition (Building Mechanics' Ready Reference Series).....16mo, mor., *1 50
Handbook for Superintendents of Construction.....16mo, mor., 4 00
Stone and Brick Masons' Edition (Building Mechanics' Ready Reference Series).....16mo, mor., *1 50
RIES—Building Stones and Clay Products.....8vo, *3 00
Clays: Their Occurrence, Properties, and Uses.....8vo, *5 00
and LEIGHTON—History of the Clay-working Industry of the United States.....8vo, *2 50
and WATSON—Engineering Geology.....(*In Press.*)
SABIN—Industrial and Artistic Technology of Paint and Varnish.....8vo, 3 00
SMITH—Strength of Material.....12mo, *1 25
SNOW—Principal Species of Wood.....8vo, 3 50

SPALDING—Hydraulic Cement.....12mo, $2 00
Text-book on Road and Pavements.....12mo, *2 00
TAYLOR and THOMPSON—Concrete Costs.....Small 8vo, *5 00
Extracts on Reinforced Concrete Design.....8vo, *2 00
Treatise on Concrete, Plain and Reinforced.....8vo, 5 00
THURSTON—Materials of Engineering. In Three Parts.....8vo, 8 00
Part I. Non-metallic Materials of Engineering and Metallurgy...8vo, 2 00
Part II. Iron and Steel.....8vo, 3 50
Part III. A Treatise on Brasses, Bronzes, and Other Alloys and their Constituents.....8vo, 2 50
TILLSON—Street Pavements and Paving Materials.....8vo, *4 00
TURNEAURE and MAURER—Principles of Reinforced Concrete Construction. 8vo, 3 50
WATERBURY—Cement Laboratory Manual.....12mo, 1 00
Laboratory Manual for Testing Materials of Construction.....12mo, *1 50
WOOD (DE V.) Treatise on the Resistance of Materials, and an Appendix on the Preservation of Timber.....8vo, 2 00
(M. P.)—Rustless Coatings: Corrosion and Electrolysis of Iron and Steel.....8vo, 4 00

RAILWAY ENGINEERING.

BERG—Buildings and Structures of American Railroads.....4to, 5 00
BROOKS—Handbook of Street Railroad Location.....16mo, mor., 1 50
BURT—Railway Station Service.....12mo, *2 00
BUTTS—Civil Engineer's Field-book.....16mo, mor., 2 50
CRANDALL—Railway and Other Earthwork Tables.....8vo, 1 50
and BARNES—Railroad Surveying.....16mo, mor., 2 00
CROCKETT—Methods for Earthwork Computations.....8vo, *1 50
DREDGE—History of the Pennsylvania Railroad. (1879).....Paper, 5 00
FISH—Earthwork Haul and Overhaul.....8vo, *1 50
FISHER—Table of Cubic Yards.....Cardboard, 0 25
GILBERT, WIGHTMAN and SAUNDERS—Subways and Tunnels of New York. 8vo, *4 00
GODWIN—Railroad Engineers' Field-book and Explorers' Guide..16mo, mor., 2 50
HUDSON—Tables for Calculating the Cubic Contents of Excavations and Embankments.....8vo, 1 00
IVES and HILTS—Problems in Surveying, Railroad Surveying and Geodesy. 16mo, mor., 1 50
MOLITOR and BEARD—Manual for Resident Engineers.....16mo, 1 00
NAGLE—Field Manual for Railroad Engineers.....16mo, mor., 3 00
ORROCK—Railroad Structures and Estimates.....8vo, *3 00
PHILBRICK—Field Manual for Engineers.....16mo, mor., 3 00
PICKELS and WILEY—Text-book on Railroad Surveying.....16mo, mor., *2 50
RAYMOND—Elements of Railroad Engineering. Second Edition.....8vo, 3 50
Railroad Engineer's Field Book.....(*In Preparation.*)
Railroad Field Geometry.....16mo, mor., 2 00
ROBERTS—Track Formulæ and Tables.....16mo, mor., 3 00
SEARLES—Field Engineering.....16mo, mor., 3 00
Railroad Spiral.....16mo, mor., 1 50
TAYLOR—Prismoidal Formulæ and Earthwork.....8vo, 1 50
WEBB—Economics of Railroad Construction.....Small 8vo, 2 50
Railroad Construction.....16mo, mor., 5 00
WELLINGTON—Economic Theory of the Location of Railways....Small 8vo, 5 00
WILSON—Elements of Railroad-Track and Construction.....12mo, 2 00

DRAWING.

BARR and WOOD—Kinematics of Machinery.....8vo, 2 50
BARTLETT—Mechanical Drawing. Third Edition.....8vo, *3 00
" " Abridgment of the Second Edition....8vo, *1 50
and JOHNSON—Engineering Descriptive Geometry.....8vo, *1 50
BISHOP—Drafting Forms. Loose Leaf Sheets, each..... *0 02
Structural Details of Hip and Valley Rafters.....Oblong large 8vo, *1 75

BISHOP—Structural Drafting ..... (*In Press.*)
BLESSING and DARLING—Descriptive Geometry 8vo, *$1 50
Elements of Drawing 8vo, *1 50
COOLIDGE—Manual of Drawing ..... 8vo, paper, 1 00
and FREEMAN—Elements of General Drafting for Mechanical Engineers ..... Oblong 4to, 2 50
DURLEY—Kinematics of Machines 8vo, 4 00
EMCH—Introduction to Projective Geometry and its Application 8vo, 2 50
FRENCH and IVES—Stereotomy 8vo, 2 50
GREENBERG and HOWE—Architectural Drafting ..... Oblong 4to, *1 50
HESS—Graphics and Structural Design 8vo, *3 00
HILL—Text-book on Shades and Shadows, and Perspective 8vo, 2 00
HOWE—Agricultural Drafting ..... oblong quarto, *1 25
Reference and Problem Sheets to accompany Agricultural Drafting. ..... each, *0 02
JAMES and MACKENZIE—Working Drawings of Machinery 8vo, *2 00
JAMISON—Advanced Mechanical Drawing 8vo, 2 00
Elements of Mechanical Drawing 8vo, 2 50
JONES—Machine Design:
Part I. Kinematics of Machinery 8vo, 1 50
Part II. Form, Strength, and Proportions of Parts 8vo, 3 00
KIMBALL and BARR—Machine Design 8vo, *3 00
MACCORD—Elements of Descriptive Geometry 8vo, 3 00
Kinematics; or, Practical Mechanism 8vo, 5 00
Mechanical Drawing 4to, 4 00
Velocity Diagrams 8vo, 1 50
MCLEOD—Descriptive Geometry ..... Small 8vo, 1 50
MAHAN—Descriptive Geometry and Stone-cutting 8vo, *1 50
Industrial Drawing. (THOMPSON.) 8vo, 3 50
MOYER—Descriptive Geometry 8vo, 2 00
REED—Topographical Drawing and Sketching 4to, 5 00
REID—Mechanical Drawing. (Elementary and Advanced.) 8vo, *2 00
Text-book of Mechanical Drawing and Elementary Machine Design. 8vo, 3 00
ROBINSON—Principles of Mechanism 8vo, 3 00
SCHWAMB and MERRILL—Elements of Mechanism 8vo, 3 00
SMITH (A. W.) and MARX—Machine Design 8vo, 3 00
(R. S.)—Manual of Topographical Drawing. (MCMILLAN.) 8vo, 2 50
TITSWORTH—Elements of Mechanical Drawing ..... Oblong large 8vo, *1 25
TRACY and NORTH—Descriptive Geometry ..... Oblong, *2 00
WARREN—Elements of Descriptive Geometry, Shadows, and Perspective. 8vo, 3 50
Elements of Machine Construction and Drawing 8vo, 7 50
Elements of Plane and Solid Free-hand Geometrical Drawing 12mo, 1 00
General Problems of Shades and Shadows 8vo, 3 00
Manual of Elementary Problems in the Linear Perspective of Forms and Shadows 12mo, 1 00
Manual of Elementary Projection Drawing 12mo, 1 50
Plane Problems in Elementary Geometry 12mo, 1 25
WEISBACH—Kinematics and Power of Transmission. (HERRMANN and KLEIN.) 8vo, 5 00
WILSON (H. M.)—Topographic, Trigonometric and Geodetic Surveying. 8vo, 3 50
(V. T.) Descriptive Geometry 8vo, *1 50
Free-hand Lettering 8vo, 1 00
Free-hand Perspective 8vo, 2 50
WOOLF—Elementary Course in Descriptive Geometry ..... Large 8vo, 3 00

ELECTRICITY AND PHYSICS.

ABEGG—Theory of Electrolytic Dissociation. (VON ENDE.) 12mo, *1 25
ANTHONY and BALL—Lecture-notes on the Theory of Electrical Measurements 12mo, 1 00
and BRACKETT—Text-book of Physics. (MAGIE.) ..... Small 8vo, 3 00
BENJAMIN—History of Electricity 8vo, 3 00
BETTS—Lead Refining and Electrolysis 8vo, 4 00
BURGESS and LE CHATELIER—Measurement of High Temperatures. Third Edition 8vo, *4 00

CALDERWOOD—Wiring Exercises (Loose Leaf Lab. Manual). (*In Preparation.*)
CLASSEN—Quantitative Analysis by Electrolysis. (HALL) 8vo, *$2 50
CLEWELL—Laboratory Manual, Direct and Alternating Current 8vo, *1 00
COLLINS—Manual of Wireless Telegraphy and Telephony 12mo, *1 50
CREHORE and SQUIER—Polarizing Photo-chronograph 8vo, 3 00
DANNEEL—Electrochemistry. (MERRIAM.) 12mo, *1 25
DAWSON—" Engineering " and Electric Traction Pocket-book .. 16mo, mor., 5 00
DOLEZALEK—Theory of the Lead Accumulator (Storage Battery). (VON ENDE.) 12mo, 2 50
DUHEM—Thermodynamics and Chemistry. (BURGESS.) 8vo, 4 00
FLATHER—Dynamometers, and the Measurement of Power 12mo, 3 00
GETMAN—Introduction to Physical Science 12mo, *1 50
GILBERT—De Magnete. (MOTTELAY.) 8vo, 2 50
HANCHETT—Alternating Currents 12mo, *1 00
HERING—Ready Reference Tables (Conversion Factors) ..... 16mo, mor., 2 50
HIGBIE—Electric Lighting and Distribution ..... (*In Preparation.*)
HOBART and ELLIS—High-speed Dynamo Electric Machinery 8vo, *6 00
HOLMAN—Precision of Measurements 8vo, 2 00
Telescope-Mirror-scale Method, Adjustments, and Tests .... Large 8vo, 0 75
HUTCHINSON—High-Efficiency Electrical Illuminants and Illumination. Small 8vo, *2 50
JONES—Electric Ignition for Combustion Motors 8vo, *4 00
KARAPETOFF—Elementary Electrical Testing (Loose Leaf Lab. Manual) 4to, Paper, *0 50
Single Exercises, each *0 02
Experimental Electrical Engineering:
Vol. I 8vo, *3 50
Vol. II 8vo, *2 50
KINZBRUNNER—Testing of Continuous-current Machines 8vo, 2 00
KOCH—Mathematics of Applied Electricity ..... Small 8vo, *3 00
LANDAUER—Spectrum Analysis. (TINGLE.) 8vo, 3 00
LAUFFER—Electrical Injuries 16mo, *0 50
Resuscitation, from Electric and Traumatic Shock, etc 16mo, *0 40
In lots of 100 Copies or more *0 30
LÖB—Electrochemistry of Organic Compounds. (LORENZ.) 8vo, 3 00
LYNDON—Development and Electrical Distribution of Water Power 8vo, *3 00
LYONS—Treatise on Electromagnetic Phenomena. Vols. I and II, 8vo, each, *6 00
MARTIN—Measurement of Induction Shocks 12mo, *1 25
MICHIE—Elements of Wave Motion Relating to Sound and Light 8vo, *4 00
MORECROFT—Continuous and Alternating Current Machinery ... Small 8vo, *1 75
MORGAN—Physical Chemistry for Electrical Engineers 12mo, *1 50
NORRIS—Introduction to the Study of Electrical Engineering 8vo, *2 50
PARSHALL and HOBART—Electric Machine Design ..... 4to, half mor., *12 50
REAGAN—Locomotives: Simple, Compound, and Electric ..... Small 8vo, 3 50
ROBINSON—Elements of Electricity 8vo, *2 50
RODENHAUSER and SCHOENAWA—Electric Furnaces in the Iron and Steel Industry (VOM BAUR.) 8vo, *3 50
ROSENBERG—Electrical Engineering. (HALDANE GEE—KINZBRUNNER.) .. 8vo, *2 00
RYAN—Design of Electrical Machinery:
Vol. I. Direct Current Dynamos 8vo, *1 50
Vol. II. Alternating Current Transformers 8vo, *1 50
Vol. III. Alternators, Synchronous Motors, and Rotary Converters. 8vo, *1 50
SCHAPPER—Laboratory Guide for Students in Physical Chemistry 12mo, 1 00
TILLMAN—Elementary Lessons in Heat 8vo, *1 50
TIMBIE—Answers to Problems in Elements of Electricity ..... 12mo, Paper, *0 25
Answers to Problems in Essentials of Electricity ..... 12mo, paper, *0 25
Electrical Measurements, A. C. and D. C. (Loose Leaf Lab. Manual). 4to, Paper, *0 85
Single Exercises, each *0 02
Elements of Electricity ..... Small 8vo, *2 00
Essentials of Electricity 12mo, *1 25
Introduction to Industrial Electricity ..... (*In Preparation.*)
and HIGBIE—Alternating Currents ..... (*In Preparation.*)
TORY and PITCHER—Manual of Laboratory Physics ..... Small 8vo, 2 00
ULKE—Modern Electrolytic Copper Refining 8vo, 3 00
WATERS—Commercial Dynamo Design 8vo, *2 00

LAW.

BRENNAN—Hand-book of Useful Legal Information for Business Men. 16mo, mor., *$5 00
DAVIS—Elements of Law 8vo, *2 50
Treatise on the Military Law of United States. Third Edition, Revised 8vo, *7 00
DUDLEY—Military Law and the Procedure of Courts-martial ..... Small 8vo, *2 50
MANUAL FOR COURTS MARTIAL ..... 16mo, mor., 1 50
WAIT—Engineering and Architectural Jurisprudence 8vo, 6 00
Sheep, 6 50
Law of Contracts 8vo, 3 00
Law of Operations Preliminary to Construction in Engineering and Architecture 8vo, 5 00
Sheep, 5 50

MATHEMATICS.

BAKER—Elliptic Functions 8vo, 1 50
BRIGGS—Elements of Plane Analytic Geometry. (BÔCHER.) 12mo, 1 00
BUCHANAN—Plane and Spherical Trigonometry 8vo, *1 00
BURNHAM—Mechanics for Machinists ..... (*In Preparation.*)
Shop Mathematics for Machinists ..... (*In Preparation.*)
BYERLY—Harmonic Functions 8vo, 1 00
CARMICHAEL—Theory of Numbers 8vo, 1 00
Theory of Relativity 8vo, 1 00
CHANDLER—Elements of the Infinitesimal Calculus 12mo, 2 00
COFFIN—Vector Analysis 12mo, *2 50
COMPTON—Manual of Logarithmic Computations 12mo, 1 50
DICKSON—College Algebra ..... Small 8vo, *1 50
Elementary Theory of Equations ..... (*In Press.*)
Introduction to the Theory of Algebraic Equations ..... Small 8vo, *1 25
EMCH—Introduction to Projective Geometry and its Application 8vo, 2 50
FISKE—Functions of a Complex Variable 8vo, 1 00
HALSTED—Elementary Synthetic Geometry 8vo, 1 50
Elements of Geometry 8vo, 1 75
Rational Geometry 12mo, *1 50
Synthetic Projective Geometry 8vo, 1 00
HANCOCK—Lectures on the Theory of Elliptic Functions 8vo, *5 00
HYDE—Grassmann's Space Analysis 8vo, 1 00
JOHNSON (J. B.) Three-place Logarithmic Tables: Vest-pocket size, paper, 100 copies, *0 15
*5 00
Mounted on heavy cardboard, 8 × 10 inches, *0 25
10 copies, *2 00
(W. W.) Abridged Editions of Differential and Integral Calculus. Small 8vo, 1 vol., 2 50
Curve Tracing in Cartesian Co-ordinates 12mo, 1 00
Differential Equations 8vo, 1 00
Elementary Treatise on Differential Calculus ..... Small 8vo, 1 50
Elementary Treatise on the Integral Calculus ..... Small 8vo, 1 50
Theoretical Mechanics 12mo, *3 00
Theory of Errors and the Method of Least Squares 12mo, 1 50
Treatise on Differential Calculus ..... Small 8vo, 3 00
Treatise on the Integral Calculus ..... Small 8vo, 3 00
Treatise on Ordinary and Partial Differential Equations ..... Small 8vo, 3 50
KARAPETOFF—Engineering Applications of Higher Mathematics:
Part I. Problems on Machine Design ..... Small 8vo, *0 75
KOCH—Mathematics of Applied Electricity ..... Small 8vo, *3 00
LAPLACE—Philosophical Essay on Probabilities. (TRUSCOTT and EMORY.) 12mo, 2 00
LE MESSURIER—Key to Professor W. W. Johnson's Differential Equations. Small 8vo, *1 75

LUDLOW—Logarithmic and Trigonometric Tables....8vo, *$1 00
and BASS—Elements of Trigonometry and Logarithmic and Other Tables....8vo, *3 00
Trigonometry and Tables published separately....Each, *2 00
MACFARLANE—Vector Analysis and Quaternions....8vo, 1 00
McMAHON—Hyperbolic Functions....8vo, 1 00
MANNING—Irrational Numbers and their Representation by Sequences and Series....12mo, 1 25
MARSH—Constructive Text Book on Practical Mathematics:
Vol. I. Industrial Mathematics....Small 8vo, *2 00
Vol. II. Technical Algebra. Part I....Small 8vo, *2 00
Vol. III. Technical Trigonometry....Small 8vo, * 00
MATHEMATICAL MONOGRAPHS. Edited by MANSFIELD MERRIMAN and ROBERT S. WOODWARD....Octavo, each, 1 00
No. 1. History of Modern Mathematics, by DAVID EUGENE SMITH.
No. 2. Synthetic Projective Geometry, by GEORGE BRUCE HALSTED.
No. 3. Determinants, by LAENAS GIFFORD WELD.
No. 4. Hyperbolic Functions, by JAMES McMAHON.
No. 5. Harmonic Functions, by WILLIAM E. BYERLY.
No. 6. Grassmann's Space Analysis, by EDWARD W. HYDE.
No. 7. Probability and Theory of Errors, by ROBERT S. WOODWARD.
No. 8. Vector Analysis and Quaternions, by ALEXANDER MACFARLANE.
No. 9. Differential Equations, by WILLIAM WOOLSEY JOHNSON.
No. 10. The Solution of Equations, by MANSFIELD MERRIMAN.
No. 11. Functions of a Complex Variable, by THOMAS S. FISKE.
No. 12. Theory of Relativity, by ROBT. D. CARMICHAEL.
No. 13. Theory of Numbers, by ROBT. D. CARMICHAEL.
MAURER—Technical Mechanics....8vo, 4 00
MERRIMAN—Method of Least Squares....8vo, 2 00
Solution of Equations....8vo, 1 00
MORITZ—Elements of Plane Trigonometry....8vo, *2 00
High School Edition....Small 8vo, *1 00
Spherical Trigonometry....8vo, *1 00
Plane and Spherical Combined....8vo, *2 50
RICE and JOHNSON—Differential and Integral Calculus. 2 vols. in one. Small 8vo, 1 50
Elementary Treatise on the Differential Calculus....Small 8vo, 3 00
SMITH—History of Modern Mathematics....8vo, 1 00
VEBLEN and LENNES—Introduction to the Real Infinestimal Analysis of One Variable....8vo, *2 00
WATERBURY—Vest Pocket Hand-book of Mathematics for Engineers. 2½×5½ inches, mor., *1 00
Enlarged Edition, Including Tables....mor., *1 50
WELD—Determinants....8vo, 1 00
WOOD—Elements of Co-ordinate Geometry....8vo, 2 00
WOODWARD—Probability and Theory of Errors....8vo, 1 00

MECHANICAL ENGINEERING.

MATERIALS OF ENGINEERING, STEAM-ENGINES AND BOILERS.

BACON—Forge Practice....12mo, 1 50
BALDWIN—Steam Heating for Buildings....12mo, 2 50
BARR and WOOD—Kinematics of Machinery....8vo, 2 50
BARTLETT—Mechanical Drawing. Third Edition....8vo, 3 00
Abridgment of the Second Edition....8vo, *1 50
BURR—Ancient and Modern Engineering and the Isthmian Canal....8vo, *3 50
CARPENTER—Heating and Ventilating Buildings....8vo, 4 00
and DIEDERICHS—Experimental Engineering....8vo, *6 00
CLERK—The Gas, Petrol and Oil Engine. Vol. I....8vo, *4 00
and BURLS—The Gas, Petrol, and Oil Engine. Vol. II....8vo, *7 50
COMPTON—First Lessons in Metal Working....12mo, 1 50
and DE GROODT—Speed Lathe....12mo, 1 50
COOLIDGE—Manual of Drawing....8vo, paper, 1 00
and FREEMAN—Elements of General Drafting for Mechanical Engineers....Oblong 4to, 2 50

CROMWELL—Treatise on Belts and Pulleys 12mo, $1 50
Treatise on Toothed Gearing 12mo, 1 50
DINGEY—Machinery Pattern Making 12mo, 2 00
DURLEY—Kinematics of Machines 8vo, 4 00
FLANDERS—Gear-cutting Machinery ..... Small 8vo, 3 00
FLATHER—Dynamometers and the Measurement of Power 12mo, 3 00
Rope Driving 12mo, 2 00
FULLER and JOHNSTON—Applied Mechanics:
Vol I. Theory of Statics and Kinetics 8vo, *2 50
Vol. II. Strength of Materials ..... (*In Preparation.*)
GILL—Gas and Fuel Analysis for Engineers 12mo, 1 25
GOSS—Locomotive Sparks 8vo, 2 00
GREENE—Elements of Heating and Ventilation 8vo, *2 50
Pumping Machinery 8vo, *4 00
HERING—Ready Reference Tables (Conversion Factors) ..... 16mo, mor., 2 50
HIRSHFELD and ULBRICHT—Gas Engines for the Farm ..... Small 8vo, *1 50
Gas Power ..... Small 8vo, *1 25
Steam Power ..... (*In Preparation.*)
HOBART and ELLIS—High Speed Dynamo Electric Machinery 8vo, *6 00
HUTTON—Gas Engine 8vo, 5 00
JAMES and MACKENZIE—Working Drawings of Machinery 8vo, *2 00
JAMISON—Advanced Mechanical Drawing 8vo, 2 00
Elements of Mechanical Drawing 8vo, 2 50
JONES—Gas Engine 8vo, 4 00
Machine Design:
Part I. Kinematics of Machinery 8vo, 1 50
Part II. Form, Strength, and Proportions of Parts 8vo, 3 00
KAUP—Machine Shop Practice ..... Small 8vo, *1 25
and CHAMBERLAIN—Text-book on Tool Making ..... (*In Preparation.*)
KENT—Mechanical Engineers' Pocket-Book ..... 16mo, mor., *5 00
KERR—Power and Power Transmission 8vo, 2 00
KIMBALL and BARR—Machine Design 8vo, *3 00
KING—Elements of the Mechanics of Materials and of Power of Transmission 8vo, *2 50
LANZA—Dynamics of Machinery 8vo, *2 50
LEONARD—Machine Shop Tools and Methods 8vo, 4 00
LEVIN—Modern Gas Engine and the Gas Producer 8vo, *4 00
MACCORD—Kinematics; or, Practical Mechanism 8vo, 5 00
Mechanical Drawing 4to, 4 00
Velocity Diagrams 8vo, 1 50
MACFARLAND—Standard Reduction Factors for Gases 8vo, 1 50
MACINTIRE—Mechanical Refrigeration 8vo, *4 00
MAHAN—Industrial Drawing. (THOMPSON.) 8vo, 3 50
MEHRTENS—Gas Engine Theory and Design ..... Small 8vo, 2 50
MORECROFT—Electric Machinery. Text-book ..... Small 8vo, *1 50
OBERG—Handbook of Small Tools ..... Small 8vo, 2 50
PARSHALL and HOBART—Electric Machine Design ..... Small 4to, half leather, *12 50
PEELE—Compressed Air Plant. Second Edition, Revised and Enlarged. 8vo, *3 50
POOLE—Calorific Power of Fuels 8vo. 3 00
PORTER—Engineering Reminiscences, 1855 to 1882 ..... 8vo, *3 00
REID—Mechanical Drawing. (Elementary and Advanced.) 8vo, *2 00
Text-book of Mechanical Drawing and Elementary Machine Design. 8vo, 3 00
RICHARDS—Compressed Air 12mo, 1 50
ROBINSON—Principles of Mechanism 8vo, 3 00
RYAN—Design of Electrical Machinery:
Vol. I. Direct Current Dynamos 8vo, *1 50
Vol. II. Alternating Current Transformers 8vo, *1 50
Vol. III. Alternators, Synchronous Motors, and Rotary Converters. 8vo, *1 50
SCHWAMB and MERRILL—Elements of Mechanism 8vo, 3 00
SMITH (O.)—Press-working of Metals 8vo, 3 00
(A. W.) and MARX—Machine Design 8vo, 3 00
SOREL—Carbureting and Combustion in Alcohol Engines. (WOODWARD and PRESTON.) ..... Small 8vo, 3 00
STONE—Practical Testing of Gas and Gas Meters 8vo, 3 50

THURSTON—Animal as a Machine and Prime Motor, and the Laws of Energetics.....12mo, $1 00
Treatise on Friction and Lost Work in Machinery and Mill Work..8vo, 3 00
TILLSON—Complete Automobile Instructor.....16mo, *1 50
TITSWORTH—Elements of Mechanical Drawing.....Oblong 8vo, *1 25
TURNER and TOWN—Pattern Making.....(*In Preparation.*)
WARREN—Elements of Machine Construction and Drawing.....8vo, 7 50
WATERBURY—Vest Pocket Hand-book of Mathematics for Engineers. 2½ ×5½ inches, mor., *1 00
Enlarged Edition, Including Tables.....mor., *1 50
WEISBACH—Kinematics and the Power of Transmission. (HERRMANN—KLEIN.).....8vo, 5 00
Machinery of Transmission and Governors. (HERRMANN—KLEIN.).8vo, 5 50
WOOD—Turbines.....8vo, 2 00

MATERIALS OF ENGINEERING.

BOTTLER—German and American Varnish Making. (SABIN.)...Small 8vo, *3 50
BURR—Elasticity and Resistance of the Materials of Engineering.....8vo, 7 50
CHURCH—Mechanics of Engineering.....8vo, 6 00
Mechanics of Solids (Being Parts I, II, III of Mechanics of Engineering). 8vo, 4 50
FULLER and JOHNSTON—Applied Mechanics:
Vol. I. Theory of Statics and Kinetics.....8vo, *2 50
Vol. II. Strength of Materials.....(*In Preparation.*)
GREENE—Structural Mechanics.....8vo, *2 50
HOLLEY—Analysis of Paint and Varnish Products.....Small 8vo, *2 50
Lead and Zinc Pigments.....Small 8vo, *3 00
JOHNSON (C. M.)—Rapid Methods for the Chemical Analysis of Special Steels, Steel-making Alloys and Graphite. Second Edition. Rewritten.....8vo, *3 00
(J. B.) Materials of Construction.....8vo, 6 00
KEEP—Cast Iron.....8vo, 2 50
KING—Elements of the Mechanics of Materials and of Power of Transmission.....8vo, *2 50
LANZA—Applied Mechanics.....8vo, 7 50
LOWE—Paints for Steel Structures.....12mo, 1 00
MAIRE—Modern Pigments and their Vehicles.....12mo, 2 00
MARTIN—Text-Book of Mechanics:
Vol. I. Statics.....12mo, *1 25
Vol. II. Kinematics and Kinetics.....12mo, *1 50
Vol. III. Mechanics of Materials.....12mo, *1 50
Vol. IV. Applied Statics.....12mo, *1 50
MAURER—Technical Mechanics.....8vo, 4 00
MERRIMAN—Mechanics of Materials.....8vo, 5 00
Strength of Materials.....12mo, *1 00
METCALF—Steel. A Manual for Steel-users.....12mo, 2 00
MILLS—Materials of Construction.....(*In Press.*)
MURDOCK—Strength of Materials.....12mo, *2 00
SABIN—Industrial and Artistic Technology of Paint and Varnish.....8vo, 3 00
SMITH (A. W.)—Materials of Machines.....12mo, 1 00
(H. E.)—Strength of Material.....12mo, *1 25
THURSTON—Materials of Engineering.....3 vols., 8vo, 8 00
Part I. Non-metallic Materials of Engineering.....8vo, 2 00
Part II. Iron and Steel.....8vo, 3 50
Part III. A Treatise on Brasses, Bronzes, and Other Alloys and their Constituents.....8vo, 2 50
WATERBURY—Laboratory Manual for Testing Materials of Construction. 12mo, *1 50
WOOD (DE V.)—Elements of Analytical Mechanics.....8vo, 3 00
Treatise on the Resistance of Materials and an Appendix on the Preservation of Timber.....8vo, 2 00
(M. P.) Rustless Coatings. Corrosion and Electrolysis of Iron and Steel.....8vo, 4 00

STEAM-ENGINES AND BOILERS.

ABRAHAM—Steam Economy in the Sugar Factory. (BAYLE.)....12mo, *$1 50
BERRY—Temperature-entropy Diagram. Third Edition Revised and Enlarged....12mo, 2 50
CARNOT—Reflections on the Motive Power of Heat. (THURSTON.)...12mo, 1 50
CHASE—Art of Pattern Making....12mo, 2 50
CREIGHTON—Steam-engine and other Heat Motors....8vo, 5 00
DAWSON—"Engineering" and Electric Traction Pocket-book...16mo, mor., 5 00
GEBHARDT—Steam Power Plant Engineering. Fourth Edition....8vo, *4 00
GOSS—Locomotive Performance....8vo, 5 00
HEMENWAY—Indicator Practice and Steam-engine Economy....12mo, 2 00
HIRSHFELD and BARNARD—Heat Power Engineering....8vo, *5 00
and ULBRICHT—Steam Power....(*In Preparation.*)
HUTTON—Heat and Heat-engines....8vo, 5 00
Mechanical Engineering of Power Plants....8vo, 5 00
KENT—Steam Boiler Economy....8vo, 4 00
KING—Steam Engineering....8vo, *4 00
KNEASS—Practice and Theory of the Injector....8vo, 1 50
MACCORD—Slide-valves....8vo, 2 00
MEYER—Modern Locomotive Construction....4to, 10 00
MILLER, BERRY, and RILEY—Problems in Thermodynamics....8vo, paper, 0 75
MOYER—Steam Turbines....8vo, 4 00
PEABODY—Manual of the Steam-engine Indicator....12mo, 1 50
Tables of the Properties of Steam and Other Vapors and Temperature-Entropy Table....8vo, 1 00
Thermodynamics of the Steam-engine and Other Heat-engines....8vo, 5 00
Thermodynamics of the Steam Turbine....8vo, *3 00
Valve-gears for Steam-engines....8vo, 2 50
and MILLER—Steam-boilers....8vo, 4 00
PERKINS—Introduction to General Thermodynamics....12mo, *1 50
PUPIN—Thermodynamics of Reversible Cycles in Gases and Saturated Vapors. (OSTERBERG.)....12mo, 1 25
RANDALL—Heat. A Manual for Technical and Industrial Students. Small, 8vo, *1 50
Exercises in Heat (Loose Leaf Lab. Manual). Single Exercises, each. *0 02
REAGAN—Locomotives: Simple, Compound, and Electric. New Edition. Small 8vo, 3 50
SINCLAIR—Locomotive Engine Running and Management....12mo, 2 00
SMART—Handbook of Engineering Laboratory Practice....12mo, 2 50
SNOW—Steam-boiler Practice....8vo, 3 00
SPANGLER—Notes on Thermodynamics....12mo, 1 00
Valve-gears....8vo, 2 50
GREENE, and MARSHALL—Elements of Steam-engineering....8vo, 3 00
THOMAS—Steam-turbines....8vo, 4 00
THURSTON—Manual of Steam-boilers, their Designs, Construction, and Operation....8vo, 5 00
Manual of the Steam-engine....2 vols., 8vo, 10 00
Part I. History, Structure, and Theory....8vo, 6 00
Part II. Design, Construction, and Operation....8vo, 6 00
WEHRENFENNIG—Analysis and Softening of Boiler Feed-water. (PATTERSON.)....8vo, 4 00
WEISBACH—Heat, Steam, and Steam-engines. (DU BOIS.)....8vo, 5 00
WHITMAN—Heat for Students of Household Science....(*In Preparation.*)
WOOD—Thermodynamics, Heat Motors, and Refrigerating Machines...8vo, 4 00

MECHANICS PURE AND APPLIED.

BURNHAM—Mechanics for Machinists....(*In Preparation.*)
CHURCH—Mechanics of Engineering....8vo, 6 00
Mechanics of Solids (Being Parts I, II, III of Mechanics of Engineering). 8vo, 4 50
Mechanics of Fluids (Being Part IV of Mechanics of Engineering). 8vo, 3 00
Mechanics of Internal Work....8vo, *1 50
Notes and Examples in Mechanics....8vo, 2 00

DANA—Text-book of Elementary Mechanics for Colleges and Schools..12mo, $1 50
DU BOIS—Elementary Principles of Mechanics:
Vol. I. Kinematics.....8vo, 3 50
Vol. II. Statics.....8vo, 4 00
Mechanics of Engineering. Vol. I.....Small 4to, 7 50
FULLER and JOHNSTON—Applied Mechanics:
Vol. I. Theory of Statics and Kinetics.....8vo, *2 50
Vol. II. Strength of Materials.....(*In Preparation.*)
GREENE—Structural Mechanics.....8vo, *2 50
HARTMANN—Elementary Mechanics for Engineering Students.....12mo, *1 25
JAMES—Kinematics of a Point and the Rational Mechanics of a Particle. Small 8vo, 2 00
JAMESON—Elementary Practical Mechanics.....12mo, *1 50
Exercises in Mechanics (Loose Leaf Manual).....4to, paper, *0 85
Single exercises, 2–5 cents, net, each, according to number of pages.
JOHNSON—Theoretical Mechanics.....12mo, *3 00
KING—Elements of the Mechanics of Materials and of Power of Transmission.....8vo, *2 50
KOTTCAMP—Exercises for the Applied Mechanics Laboratory, Loose Leaf Laboratory Manual.....Oblong 4to, paper, *1 00
LANZA—Applied Mechanics.....8vo, 7 50
MARTIN—Text Book of Mechanics:
Vol. I. Statics.....12mo, *1 25
Vol. II. Kinematics and Kinetics.....12mo, *1 50
Vol. III. Mechanics of Materials.....12mo, *1 50
Vol. IV. Applied Statics.....12mo, *1 50
MAURER—Technical Mechanics. Third Edition. Rewritten.....8vo, *2 50
MERRIMAN—Elements of Mechanics.....12mo, *1 00
Mechanics of Materials.....8vo, 5 00
MICHIE—Elements of Analytical Mechanics.....8vo, *4 00
ROBINSON—Principles of Mechanism.....8vo, *3 00
SANBORN—Mechanics Problems.....Small 8vo, *1 50
SCHWAMB and MERRILL—Elements of Mechanism.....8vo, 3 00
WOOD—Elements of Analytical Mechanics.....8vo, 3 00
Principles of Elementary Mechanics.....12mo, 1 25

MEDICAL.

ABDERHALDEN—Physiological Chemistry in Thirty Lectures. (HALL and DEFREN.).....8vo, *5 00
BOLDUAN—Immune Sera.....12mo, *1 50
BORDET—Studies in Immunity. (GAY.).....8vo, 6 00
CHAPIN—The Sources and Modes of Infection.....Small 8vo, *3 00
COHNHEIM—Enzymes.....12mo, *1 50
DAVENPORT—Statistical Methods with Special Reference to Biological Variations.....16mo, mor., 1 50
DE FURSAC—Manual of Psychiatry. (ROSANOFF and COLLINS.).Small 8vo, *2 50
EFFRONT—Enzymes and Their Applications. (PRESCOTT.).....8vo, 3 00
EHRLICH—Studies on Immunity. (BOLDUAN.).....8vo, 6 00
EULER—General Chemistry of the Enzymes. (POPE.).....8vo, *3 00
FISCHER—Nephritis.....Small 8vo, *2 50
Oedema.....8vo, *2 00
Physiology of Alimentation.....Small 8vo, *2 00
FULLER—Qualitative Analysis of Medicinal Preparations.....12mo, *1 50
HAMMARSTEN—Text-book on Physiological Chemistry. (MANDEL.)....8vo, *4 00
JACKSON—Directions for Laboratory Work in Physiological Chemistry.8vo, 1 25
LASSAR-COHN—Praxis of Urinary Analysis. (LORENZ.).....12mo, 1 00
LAUFFER—Electrical Injuries.....16mo, *0 50
MANDEL—Hand-book for the Bio-Chemical Laboratory.....12mo, 1 50
MARTIN—Measurement of Induction Shocks.....12mo, *1 25
NELSON—Analysis of Drugs and Medicines.....12mo, *3 00
PAULI—Physical Chemistry in the Service of Medicine. (FISCHER.)...12mo, *1 25
POZZI-ESCOT—Toxins and Venoms and their Antibodies. (COHN.)...12mo, *1 00
ROSTOSKI—Serum Diagnosis. (BOLDUAN.).....12mo, 1 00
RUDDIMAN—Incompatibilities in Prescriptions.....8vo, 2 00
Whys in Pharmacy.....12mo, 1 00

SALKOWSKI—Physiological and Pathological Chemistry. (ORNDORFF.) .8vo, $2 50
SATTERLEE—Outlines of Human Embryology 12mo, *1 25
SMITH—Lecture Notes on Chemistry for Dental Students.....8vo, *2 50
VON BEHRING—Suppression of Tuberculosis. (Bolduan.).....12mo, 1 00
WHIPPLE—Typhoid Fever.....Small 8vo, *3 00
WOODHULL—Military Hygiene for Officers of the Line.....Small 8vo, *1 50
Personal Hygiene.....12mo, *1 00
WORCESTER and ATKINSON—Small Hospitals Establishment and Maintenance, and Suggestions for Hospital Architecture, with Plans for a Small Hospital.....12mo, 1 25

METALLURGY.

BETTS—Lead Refining by Electrolysis.....8vo, 4 00
BOLLAND—Encyclopedia of Founding and Dictionary of Foundry Terms used in the Practice of Moulding.....12mo, 3 00
Iron Founder.....12mo, 2 50
BORCHERS—Metallurgy. (HALL and HAYWARD.).....8vo, *3 00
BURGESS and LE CHATELIER—Measurement of High Temperatures. Third Edition.....8vo, *4 00
DOUGLAS—Untechnical Addresses on Technical Subjects.....12mo, 1 00
GOESEL—Minerals and Metals: A Reference Book.....16mo, mor., 3 00
ILES—Lead-smelting.....12mo, *2 50
JOHNSON—Rapid Methods for the Chemical Analysis of Special Steels, Steel-making Alloys and Graphite. 2d Edition. Rewritten..8vo, *3 00
KEEP—Cast Iron.....8vo, 2 50
METCALF—Steel. A Manual for Steel-users.....12mo, 2 00
MINET—Production of Aluminum and its Industrial Use. (WALDO.)..12mo, 2 50
PALMER—Foundry Practice.....Small 8vo, *2 00
PRICE and MEADE—Technical Analysis of Brass.....12mo, *2 00
RODENHAUSER and SCHOENAWA—Electric Furnaces in the Iron and Steel Industry. (VOM BAUR.).....8vo, *3 50
RUER—Elements of Metallography. (MATHEWSON.).....8vo, *3 00
SMITH—Materials of Machines.....12mo, 1 00
TATE and STONE—Foundry Practice.....12mo, 2 00
THURSTON—Materials of Engineering. In Three Parts.....8vo, 8 00
Part I. Non-metallic Materials of Engineering, see Civil Engineering, page 10.
Part II. Iron and Steel.....8vo, 3 50
Part III. A Treatise on Brasses, Bronzes, and Other Alloys and Their Constituents.....8vo, 2 50
ULKE—Modern Electrolytic Copper Refining.....8vo, 3 00
WEST—American Foundry Practice.....12mo, 2 50
Moulders Text Book.....12mo, 2 50

MILITARY AND MARINE ENGINEERING.

ARMY AND NAVY.

BERNADOU—Smokeless Powder, Nitro-cellulose, and the Theory of the Cellulose Molecule.....12mo, 2 50
CHASE—Art of Pattern Making.....12mo, 2 50
Screw Propellers and Marine Propulsion.....8vo, 3 00
CLOKE—Enlisted Specialists' Examiner.....8vo, *2 00
Gunner's Examiner.....8vo, *1 50
CRAIG—Azimuth.....4to, 3 50
CREHORE and SQUIER—Polarizing Photo-chronograph.....8vo, 3 00
DAVIS—Elements of Law.....8vo, *2 50
Treatise on the Military Law of United States. 3d Ed., Revised. 8vo, *7 00
DUDLEY—Military Law and the Procedure of Courts-martial....Small 8vo, *2 50
DURAND—Resistance and Propulsion of Ships.....8vo, 5 00
DYER—Handbook of Light Artillery.....12mo, *3 00
DYSON—Screw Propellers and Estimation of Power. Two Volumes: *7 50
Vol. I. Text.....8vo,
Vol. II. Plates.....Oblong,

EISSLER—Modern High Explosives....8vo, $4 00
FIEBEGER—Text-book on Field Fortification....Small 8vo, *2 00
HAMILTON and BOND—The Gunner's Catechism....18mo, 1 00
HOFF—Elementary Naval Tactics....8vo, *1 50
INGALLS—Handbook of Problems in Direct Fire....8vo, 4 00
Interior Ballistics....8vo, *3 00
LISSAK—Ordnance and Gunnery....8vo, *6 00
LUDLOW—Logarithmic and Trigonometric Tables....8vo, *1 00
LYONS—Treatise on Electromagnetic Phenomena. Vols. I. and II., 8vo, each, *6 00
MAHAN—Permanent Fortifications. (MERCUR.)....8vo, half mor., *7 50
MANUAL FOR COURTS-MARTIAL....16mo, mor., 1 50
MERCUR—Attack of Fortified Places....12mo, *2 00
Elements of the Art of War....8vo, *4 00
NIXON—Adjutants' Manual....24mo, 1 00
PEABODY—Computations for Marine Engine....8vo, *2 50
Naval Architecture....8vo, 7 50
Propellers....8vo, 1 25
PHELPS—Practical Marine Surveying....8vo, *2 50
PUTNAM—Nautical Charts....8vo, 2 00
RUST—Ex-meridian Altitude, Azimuth and Star-Finding Tables....8vo, 5 00
SELKIRK—Catechism of Manual of Guard Duty....24mo, *0 50
SHARPE—Art of Subsisting Armies in War....18mo, mor., 1 50
TAYLOR—Speed and Power of Ships. 2 vols. Text 8vo, plates oblong 4to, *7 50
TUPES and POOLE—Manual of Bayonet Exercise and Musketry Fencing. 24mo, leather, *0 50
WEAVER—Military Explosives....8vo, *3 00
WOODHULL—Military Hygiene for Officers of the Line....Small 8vo, *1 50

MINERALOGY.

BROWNING—Introduction to Rarer Elements....8vo, *1 50
BRUSH—Manual of Determinative Mineralogy. (PENFIELD.)....8vo, 4 00
BUTLER—Pocket Hand-book of Blowpipe Analysis....16mo, *0 75
Pocket Hand-book of Minerals....16mo, mor., 3 00
CHESTER—Catalogue of Minerals....8vo, paper, 1 00
Cloth, 1 25
CRANE—Gold and Silver....8vo, *5 00
DANA—First Appendix to Dana's New "System of Mineralogy.". Large 8vo, 1 00
Manual of Mineralogy. (FORD.)....12mo, *2 00
Minerals, and How to Study Them....12mo, 1 50
System of Mineralogy....Large 8vo, half leather, 12 50
Text-book of Mineralogy....8vo, 4 00
DOUGLAS—Untechnical Addresses on Technical Subjects....12mo, 1 00
EAKLE—Mineral Tables....8vo, 1 25
ECKEL—Building Stones and Clays....8vo, *3 00
GOESEL—Minerals and Metals: A Reference Book....16mo, mor., 3 00
GROTH—The Optical Properties of Crystals. (JACKSON.)....8vo, *3 50
Introduction to Chemical Crystallography. (MARSHALL.)....12mo, 1 25
HAYES—Handbook for Field Geologists....16mo, mor., *1 50
IDDINGS—Igneous Rocks....8vo, 5 00
Rock Minerals....8vo, 5 00
JOHANNSEN—Determination of Rock-forming Minerals in Thin Sections, 8vo, With Thumb Index, 5 00
LEWIS—Determinative Mineralogy....Small 8vo, *1 50
MCLEOD—The A. B. C. of the Useful Minerals....16mo, mor., *1 00
MARTIN—Laboratory Guide to Qualitative Analysis with the Blowpipe.12mo, *0 60
MERRILL—Non-metallic Minerals: Their Occurrence and Uses....8vo, 4 00
Stones for Building and Decoration....8vo, 5 00
PENFIELD—Notes on Determinative Mineralogy and Record of Mineral Tests....8vo, paper, *0 50
Tables of Minerals, Including the Use of Minerals and Statistics of Domestic Production....8vo, 1 00
PIRSSON—Rocks and Rock Minerals....12mo, *2 50
RICHARDS—Synopsis of Mineral Characters....12mo, mor., *1 25

RIES—Building Stones and Clay Products.....8vo, *$3 00
Clays: Their Occurrence, Properties and Uses.....8vo, *5 00
and LEIGHTON—History of the Clay-working Industry of the United States.....8vo, *2 50
and WATSON—Engineering Geology.....(*In Press.*)
ROWE—Practical Mineralogy Simplified.....12mo, *1 25
TILLMAN—Text-book of Important Minerals and Rocks.....8vo, *2 00
WASHINGTON—Manual of the Chemical Analysis of Rocks.....8vo, 2 00

MINING.

BEARD—Mine Gases and Explosions.....Small 8vo, *3 00
BRUNSWIG—Explosives. (MUNROE and KIBLER.).....Small 8vo, *3 00
BRUNTON and DAVIS—Modern Practice in Tunneling.....(*In Press.*)
CRANE—Gold and Silver.....8vo, *5 00
Index of Mining Engineering Literature, Vol. I.....8vo, *4 00
8vo, mor., *5 00
Vol. II.....8vo, *3 00
8vo, mor., *4 00
Ore Mining Methods.....8vo, *3 00
DANA and SAUNDERS—Rock Drilling.....8vo, *4 00
DOUGLAS—Untechnical Addresses on Technical Subjects.....12mo, 1 00
EISSLER—Modern High Explosives.....8vo, 4 00
GILBERT, WIGHTMAN and SAUNDERS—Subways and Tunnels of New York. 8vo, *4 00
GOESEL—Minerals and Metals: A Reference Book.....16mo, mor., 3 00
IHLSENG—Manual of Mining.....8vo, 5 00
ILES—Lead Smelting.....12mo, *2 50
PEELE—Compressed Air Plant.....8vo, *3 50
RIEMER—Shaft Sinking under Difficult Conditions. (CORNING and PEELE.) 8vo, 3 00
WEAVER—Military Explosives.....8vo, *3 00
WILSON—Cyanide Processes.....12mo, 1 50
Hydraulic and Placer Mining.....12mo, 2 50

SANITARY SCIENCE.

BASHORE—Outlines of Practical Sanitation.....12mo, *1 25
Sanitation of a Country House.....12mo, 1 00
Sanitation of Recreation Camps and Parks.....12mo, 1 00
FOLWELL—Sewerage. (Designing, Construction, and Maintenance.)...8vo, 3 00
Water-supply Engineering.....8vo, 4 00
FOWLER—Sewage Works Analyses.....12mo, 2 00
GERHARD—Guide to Sanitary Inspections.....12mo, 1 50
Modern Baths and Bath Houses.....8vo, *3 00
Sanitation of Public Buildings.....12mo, 1 50
GERHARD—The Water Supply, Sewerage, and Plumbing of Modern City Buildings.....8vo, *4 00
HAZEN—Clean Water and How to Get It. Second Edition.....Small 8vo, 1 50
Filtration of Public Water-supplies.....8vo, 3 00
HOOKER—Chloride of Lime in Sanitation.....8vo, 3 00
KINNICUTT, WINSLOW and PRATT—Sewage Disposal.....8vo, *3 00
LEACH-WINTON—Inspection and Analysis of Food. Third Edition, Revised and Enlarged by Dr. Andrew L. Winton.....8vo, 7 50
MARSTON and ERINGER—Sewers and Drains.....(*In Preparation.*)
MASON—Examination of Water. (Chemical and Bacteriological.)....12mo, 1 25
Water-supply. (Considered principally from a Sanitary Standpoint.) 8vo, 4 00
MERRIMAN—Elements of Sanitary Engineering.....8vo, *2 00
OGDEN—Sewer Construction.....8vo, 3 00
Sewer Design.....12mo, 2 00
and CLEVELAND—Practical Methods of Sewage Disposal for Residences, Hotels and Institutions.....8vo, *1 50
PARSONS—Disposal of Municipal Refuse.....8vo, 2 00

PRESCOTT and WINSLOW—Elements of Water Bacteriology, with Special Reference to Sanitary Water Analysis. Third Edition, Rewritten. Small 8vo, *$1 75

PRICE—Handbook on Sanitation. Third Edition. Rewritten. 12mo, *1 50

The Modern Factory. (*In Press.*)

RICHARDS—Conservation by Sanitation. 8vo, 2 50

Cost of Cleanness. 12mo, 1 00

Cost of Food. A Study in Dietaries. 12mo, 1 00

Cost of Living as Modified by Sanitary Science. 12mo, 1 00

Cost of Shelter. 12mo, 1 00

Laboratory Notes on Industrial Water Analysis. 8vo, *0 50

RICHARDS and WOODMAN—Air, Water, and Food from a Sanitary Standpoint. 8vo, 2 00

RICHEY—Plumbers', Steam-fitters', and Tinners' Edition (Building Mechanics' Ready Reference Series). 16mo, mor., *1 50

RIDEAL—Disinfection and the Preservation of Food. 8vo, 4 00

SOPER—Air and Ventilation of Subways. 12mo, 2 50

TURNEAURE and RUSSELL—Public Water-supplies. 8vo, 5 00

VENABLE—Garbage Crematories in America. 8vo, 2 00

Method and Devices for Bacterial Treatment of Sewage. 8vo, 3 00

WARD and WHIPPLE—Freshwater Biology. (*In Press.*)

WHIPPLE—Microscopy of Drinking-water. 8vo, 3 50

Typhoid Fever. Small 8vo, *3 00

Value of Pure Water. Small 8vo, 1 00

MISCELLANEOUS.

BIGELOW—A Meteorological Treatise. (*In Press.*)

BURT—Railway Station Service. 12mo, *2 00

CHAPIN—How to Enamel. 12mo, *1 00

FERREL—Popular Treatise on the Winds. 8vo, 4 00

FITZGERALD—Boston Machinist. 18mo, 1 00

FRITZ—Autobiography of John. 8vo, *2 00

GANNETT—Statistical Abstract of the World. 24mo, 0 75

GREEN—Elementary Hebrew Grammar. 12mo, 1 25

HAINES—American Railway Management. 12mo, 2 50

HANAUSEK—The Microscopy of Technical Products. (WINTON.). 8vo, 5 00

JACOBS—Betterment Briefs. A Collection of Published Papers on Organized Industrial Efficiency. 8vo, 3 50

KENT—Investigating an Industry. 12mo, *1 00

METCALFE—Cost of Manufactures, and the Administration of Workshops. 8vo, 5 00

PARKHURST—Applied Methods of Scientific Management. 8vo, *2 00

PUTNAM—Nautical Charts. 8vo, 2 00

RICKETTS—History of Rensselaer Polytechnic Institute, 1824–1894. Small 8vo, 3 00

ROTCH and PALMER—Charts of the Atmosphere for Aeronauts and Aviators. Oblong 4to, *2 00

ROTHERHAM—Emphasised New Testament. Large 8vo, 2 00

RUST—Ex-Meridian Altitude, Azimuth and Star-finding Tables. 8vo, 5 00

STANDAGE—Decoration of Wood, Glass, Metal, etc. 12mo, 2 00

TOMPKINS—The Science of Knitting. (*In Press.*)

WESTERMAIER—Compendium of General Botany. (SCHNEIDER.). 8vo, 2 00

WINSLOW—Elements of Applied Microscopy. 12mo, 1 50